This is a digital copy of a book that was preserved for generations on library shelves before it was carefully scanned by Google as part of a project to make the world's books discoverable online.

It has survived long enough for the copyright to expire and the book to enter the public domain. A public domain book is one that was never subject to copyright or whose legal copyright term has expired. Whether a book is in the public domain may vary country to country. Public domain books are our gateways to the past, representing a wealth of history, culture and knowledge that's often difficult to discover.

Marks, notations and other marginalia present in the original volume will appear in this file - a reminder of this book's long journey from the publisher to a library and finally to you.

Usage guidelines

Google is proud to partner with libraries to digitize public domain materials and make them widely accessible. Public domain books belong to the public and we are merely their custodians. Nevertheless, this work is expensive, so in order to keep providing this resource, we have taken steps to prevent abuse by commercial parties, including placing technical restrictions on automated querying.

We also ask that you:

+ *Make non-commercial use of the files* We designed Google Book Search for use by individuals, and we request that you use these files for personal, non-commercial purposes.
+ *Refrain from automated querying* Do not send automated queries of any sort to Google's system: If you are conducting research on machine translation, optical character recognition or other areas where access to a large amount of text is helpful, please contact us. We encourage the use of public domain materials for these purposes and may be able to help.
+ *Maintain attribution* The Google "watermark" you see on each file is essential for informing people about this project and helping them find additional materials through Google Book Search. Please do not remove it.
+ *Keep it legal* Whatever your use, remember that you are responsible for ensuring that what you are doing is legal. Do not assume that just because we believe a book is in the public domain for users in the United States, that the work is also in the public domain for users in other countries. Whether a book is still in copyright varies from country to country, and we can't offer guidance on whether any specific use of any specific book is allowed. Please do not assume that a book's appearance in Google Book Search means it can be used in any manner anywhere in the world. Copyright infringement liability can be quite severe.

About Google Book Search

Google's mission is to organize the world's information and to make it universally accessible and useful. Google Book Search helps readers discover the world's books while helping authors and publishers reach new audiences. You can search through the full text of this book on the web at `http://books.google.com/`

Library
of the
University of Wisconsin

A TEXT-BOOK

ON

APPLIED MECHANICS.

VOLUME II.

STANDARD SCIENTIFIC TEXT-BOOKS.

BY PROFESSOR JAMIESON, M.INST.C.E., M.INST.E.E., F.R.S.E.,
The Glasgow and West of Scotland Technical College.

In Crown 8vo, Cloth.

ADVANCED TEXT-BOOKS.

JAMIESON'S STEAM and STEAM ENGINES. With over 200 Illustrations, Folding Plates, and Examination Papers. TWELFTH EDITION. 8s. 6d.

"The best book yet published for the use of students."—*Engineer.*

JAMIESON'S APPLIED MECHANICS (Advanced). Vol. I.—The Principle of Work and its Applications; Gearing. 7s. 6d. THIRD EDITION.

"Fully maintains the reputation of the author—more we cannot say."—*Practical Engineer.*

Vol. II.—Motion and Energy; Strength of Materials; Graphic Statics; Hydraulics and Hydraulic Machinery. SECOND EDITION, Revised and Enlarged. 8s. 6d.

"WELL and LUCIDLY WRITTEN."—*The Engineer.*

Complete in Two Volumes; each Volume complete in itself and sold separately.

ELEMENTARY MANUALS.

JAMIESON'S ELEMENTARY MANUAL OF STEAM AND THE STEAM ENGINE. With many Illustrations and Examination Questions. SIXTH EDITION. 3s. 6d.

"Quite the right sort of book."—*Engineer.*

JAMIESON'S APPLIED MECHANICS (Introductory Manual). With numerous Illustrations and Examination Questions. THIRD EDITION, Revised and Enlarged. 3s. 6d.

"Nothing is taken for granted. . . . The work has very high qualities, which may be condensed into one word—'clear.'"—*Science and Art.*

JAMIESON'S MAGNETISM AND ELECTRICITY (Introductory Manual). With 246 Illustrations and Examination Questions. FOURTH EDITION. 3s. 6d.

"A thoroughly trustworthy text-book."—*Nature.*

ELECTRICAL RULES AND TABLES (A Pocket-Book of). For the use of Electricians and Engineers. By J. MUNRO, C.E., and Prof. JAMIESON. THIRTEENTH EDITION, Revised. Pocket Size. With Diagrams. 3s. 6d.

"WONDERFULLY PERFECT. . . . Worthy of the highest commendation we can give it."—*Electrician.*

VALVES AND VALVE GEARING: Including Corliss Valves and Trip Gear. A Practical Text-book for the use of Engineers, Draughtsmen, and Students. By CHARLES HURST, Practical Draughtsman. With numerous Illustrations and Folding Plates. In large 8vo. 7s. 6d.

"Mr. HURST'S 'VALVES and VALVE-GEARING' will prove a very valuable aid, and tend to the production of Engines of SCIENTIFIC DESIGN and ECONOMICAL WORKING. . . . Will be largely sought after by Students and Designers."—*Marine Engineer.*

HEAT EFFICIENCY OF STEAM BOILERS: Land and Marine. With many Tests and experiments on different Types of Boilers, as to the Heating Value of Fuels, &c.; with Analyses of Gases and Amount of Evaporation, and Suggestions for the Testing of Boilers. BY BRYAN DONKIN, M.Inst.C.E. In 4to, Handsome Cloth. With Plates illustrating Progress made during the present Century, and the best Modern Practice. 25s.

"In Mr. DONKIN'S book WE HAVE THE ESSENCE of all the books, papers, and reports concerning steam boilers which have been written, printed, and given to the world for many years at home and abroad."—*Engineer.*

"A WORK OF REFERENCE which is at present UNIQUE, and possesses the invaluable property that it will give an answer to almost any question connected with the performance of boilers of any type that it is possible to ask."—*Engineer.*

*** For Details regarding the above Standard Works, see the Catalogue at the end of this volume.

LONDON: CHARLES GRIFFIN & CO., LTD., EXETER STREET, STRAND.





130-TON STEAM CR. HARBOUR.

(*For 1*

Frontispiece.]

A TEXT-BOOK

ON

APPLIED MECHANICS.

SPECIALLY ARRANGED
FOR THE USE OF SCIENCE AND ART,
CITY AND GUILDS OF LONDON INSTITUTE,
AND OTHER ENGINEERING STUDENTS.

BY

ANDREW JAMIESON, M.Inst.C.E.,

PROFESSOR OF ELECTRICAL ENGINEERING IN THE GLASGOW AND WEST OF SCOTLAND TECHNICAL COLLEGE; MEMBER OF THE INSTITUTE OF ELECTRICAL ENGINEERS; FELLOW OF THE ROYAL SOCIETY, EDINBURGH; AUTHOR OF TEXT-BOOKS ON STEAM AND STEAM-ENGINES, ELEMENTARY APPLIED MECHANICS, MAGNETISM AND ELECTRICITY, ELECTRICAL RULES AND TABLES, ETC.

VOLUME II.

SECOND EDITION, Revised and Enlarged.

With numerous Diagrams and Examination Questions.

LONDON:
CHARLES GRIFFIN AND COMPANY, LIMITED;
EXETER STREET, STRAND.
1898.

[*All Rights Reserved.*]

C/09906
56753 SD
FEB 4 1901 .J24
.2
2

PREFACE TO SECOND EDITION.

THE First Edition has been very carefully revised and considerably extended. All errors known to the Author have been corrected, and the Questions which were set at the 1898 Examinations of the Science and Art Department have been inserted at the end of the several Lectures to which they relate.

PART VI. on HYDRAULICS and HYDRAULIC MACHINES has been completed by the addition of three new Lectures, which treat of the principles of Hydrostatics and Hydrokinetics, as well as many of their most important applications to hydraulic machinery.

I am indebted to several firms for illustrations, to Mr. T. R. Murray for his kind suggestions regarding the Lecture on Refrigeration, as well as to Messrs. David Robertson, Junr., John S. Nicholson, and Chas. J. Sellar, for their assistance in connection with this Edition.

ANDREW JAMIESON.

THE GLASGOW AND WEST OF SCOTLAND
TECHNICAL COLLEGE,
September, 1898.

PREFACE TO VOLUME II.

THIS Text-Book has been written expressly for Second and Third Year Students of Applied Mechanics. It, therefore, forms a suitable companion to the Author's *Text-Book on Steam and Steam Engines.* It also forms a direct continuation of his *Elementary Manual on Applied Mechanics;* for it covers the Advanced Stage of the Science and Art Departments Examinations, and treats on many points demanded by the Honours Section. It will, moreover, be found of considerable use to those who aim at passing the Advanced and Honours Stages of the same Examinations in Machine Construction and Drawing, as well as the Examinations of the City and Guilds of London Institute in Mechanical Engineering. At the same time, the treatment of the subject is sufficiently general to satisfy the wants of other engineering students, who do not happen to have these Special Examinations in view.

The book has been divided into six parts:—

I. The Principle of Work and its Applications.
II. Gearing.
III. Motion and Energy.
IV. Graphic Statics.
V. Strength of Materials.
VI. Hydraulics and Hydraulic Machinery.

Parts I. and II. were issued as Volume I., and the remaining Parts now form Volume II. This volume consists of Lectures XX. to XXXIV. under the following general headings:—Velocity and Acceleration—Motion and Energy—Energy of Rotation and Centrifugal Force—Engine Governors and other Applications of Centrifugal Force—Framed Structures—Roof Frames—Deficient Frames—Cranes—Beams and Girders—Stress and Strain, and Bodies under Tension—Strength of Shafts—Strength of Beams and Girders—Deflection of Beams and Girders—Hydraulic Appliances—Refrigerating Machines.

In each Part special reference has been made to the latest and best books, and to papers read before leading Engineering Societies.

In each Part a number of examples have been fully worked out, and at the end of each Lecture a series of carefully-selected questions has been arranged, in the precise order of, and relating solely to, the subject matter of the Lecture, so that Teachers and Students may have a minimum of trouble in finding suitable examples.

Volume I. having been so kindly received, and having already passed into a Second Edition, it has been considered advisable to issue this Volume in time for the coming session, many Teachers having expressed a wish to have the continuation of the work at once. Later, the Author hopes to have the opportunity of still further amplifying and extending Part VI.

In conclusion, he has to thank many of his old Students and friends in connection with the production of the work; more especially, for the help which he received from Mr. Robert M. Anderson with Parts I. to III.; Mr. John H. A. MacIntyre with Part IV.; and Mr. John Anderson

with Part V. He has also to thank Mr. Alexander H. Weddell and Mr. John S. Nicholson for preparing numerous drawings, and the various firms who supplied illustrations of their mechanical appliances. Finally, he has received much assistance from Mr. David A. Ramsay, Mr. J. Fred. Nielson, and Mr. David Robertson, Jun., in preparing the manuscript and revising the proofs.

Great care has been taken to avoid errors, but if any should be observed by readers, the Author will be glad to have them pointed out, and to receive any suggestions tending to increase the usefulness of this book.

ANDREW JAMIESON.

THE GLASGOW AND WEST OF SCOTLAND
TECHNICAL COLLEGE,
September, 1897.

CONTENTS.

PART III.—MOTION AND ENERGY.

PAGES

LECTURE XX.

Velocity and Acceleration.

Definitions — Motion — Velocity — Acceleration — Graphical Methods—Velocity Diagrams—Falling Bodies—General Formulæ—Rotation—Angular Velocity—Circular Measure —Angular Acceleration—Composition and Resolution of Velocities—Parallelogram of Velocities—Triangle of Velocities—Polygon of Velocities—Rectangular Resolution—Composition and Resolution of Accelerations—The Hodograph—Hodograph for Motion in a Circle—Examples I., II., III., and IV.—Instantaneous Centre—Questions, . 1-29

LECTURE XXI.

Motion and Energy.

Quantity of Motion—Definition of Momentum—Example I.—Newton's Laws of Motion—Examples II. and III.—Motion on a Double Inclined Plane—Examples IV. and V.—Energy —Definition of Energy—Definitions of Potential and Kinetic Energy—Expression for Kinetic Energy—Energy Equations—Examples VI., VII., and VIII.—Questions, . 30-55

LECTURE XXII.

Energy of Rotation and Centrifugal Force.

Energy of a Rotating Body—Moment of Inertia of a Body about an Axis—Definitions of Moment of Inertia and Radius of Gyration — Propositions I., II., and III. — Methods of Calculating Moments of Inertia—Examples I., II., and III.—Tables of Radii of Gyration of Solids and Sections =Equation of Energy for a Rotating Body—Examples

PAGES

IV., V., VI., and VII.—Determination of Energy of Fly-wheels—Centripetal and Centrifugal Forces—Definitions of Centripetal and Centrifugal Forces — Example VIII.—Straining Actions due to Centrifugal Forces — Example IX.—Questions, ... 56-91

LECTURE XXIII.

Engine Governors and other Applications of Centrifugal Force.

Governing of Engines — Watt's Governor — Action of Watt's Governor—Theory of Watt's Governor—Conical Pendulum —Example I.—Common Pendulum Governor—Crossed-Arm Governor — Parabolic Governors — Galloway's Parabolic Governor—Porter's loaded Governor—Theory of Porter's Governor—Example II.—Spring loaded Governors—Proell's and Hartnell's Spring Governors — Macfarlane's Safety Governor—Willans' Spring Governor—Pickering Governor —Governing by Throttling and Variable Expansion—Shaft Governors—Relays—Knowles' Supplemental Governor—Inertia Governors—Flywheels—Balancing Machinery—Weston Self-balancing Centrifugal Machine—Questions, . 92-131

PART IV.—GRAPHIC STATICS.

LECTURE XXIV.

Framed Structures.

Graphic Statics—A Framed Structure—Classification of Frames —Firm Frames—Deficient Frames—Redundant Frames—Conditions of Equilibrium—Bow's Method of Lettering—Solution of a Triangular Frame—Reciprocal Figure for a Joint—Definition of a Strut—Definition of a Tie—Stress Diagram — Determination of the Kind of Stress in a Bar—Firm Quadrilateral Frame—Firm Triangular Frame—Firm Frame—Firm Frame with Mansard Outline —Questions, ... 132-149

PAGES

LECTURE XXV.

Roof Frames.

Substituted Frames—King Post Truss—Right-Angled Strut Truss—Roof Truss—Load at an Internal Joint of a Frame—Modified French Truss—Bowstring Truss—Questions, . 150-169

LECTURE XXVI.

Deficient Frames.

Deficient Frames—Iron King Post Truss—Queen Post Frame—Solution of the Second Method—Solution of the Third Method—Solution of the Fifth Method—Yieldingness—Questions, ... 170-181

LECTURE XXVII.

Cranes.

Wharf Crane—Example I.—Common Jib Crane—Balanced Jib Crane—Derrick or Scotch Crane—Foundry Crane—Sheer Legs—Example II.—130-Ton Steam Crane—Tables of Dimensions and Weights of 130-Ton Crane—Example III.—Questions, ... 182-205

LECTURE XXVIII.

Beams and Girders.

Reactions on a Beam—First Method—Resultant of the Loads on a Beam—Reactions on a Beam—Second Method—Fink Truss—Trapezoidal Truss of Three Panels—Trapezoidal Truss of Five Panels—Example I.—Warren Girder—Linville or N Girder—Lattice Girder—Redundant Frame—Five Bay Lattice Girder—Lattice Girder loaded at Top Joints—Bending Moment—Definition—Shearing Force—Definition—Cantilever Uniformly Loaded—Examples II. and III.—Centre of Gravity of an Area—Moment of Inertia of an Area—Proof—Engine Mechanism—Questions, . 206-239

PART V.—STRENGTH OF MATERIALS.

PAGES

LECTURE XXIX.

Stress and Strain, and Bodies under Tension.

Stress—Definition of Intensity of Stress—Relation between Normal and Tangential Stresses—Strain—Example I.—Coefficient or Modulus of Elasticity—Limit of Elasticity—Work done in Stretching a Bar—Resilience—Example II.—Sudden Pull or Live Load—Shrunk Rings—Example III.—Strength of Thin Cylinders—Helical Seams—Strength of Thick Cylinders—Example IV.—Strength of Suspended Chains and Wires—Example V.—Questions, . 240-255

LECTURE XXX.

Strength of Shafts.

Torsional Strength of Shafts—Examples I., II., and III.—Strength of Shafts subjected to Combined Twisting and Bending—Theorem—Examples IV. and V.—Stiffness of Shafts—Angle of Twist—Example VI.—Questions, ... 256-271

LECTURE XXXI.

Strength of Beams and Girders.

Strength of Beams and Girders—Definitions of Shearing Force and Bending Moment—Beam Fixed at one end and Loaded at the other—Beam Fixed at one end and Loaded Uniformly—Beam Supported at both ends and Loaded in the middle—Example I.—Beam Supported at ends and Loaded anywhere—Beam Supported at both ends and Loaded Uniformly—Examples II. and III.—Floating Beams—Travelling Loads—Two Loads Moving at a Fixed Distance apart—Example IV.—Distributed Travelling Load—Questions, ... 272-293

PAGES

LECTURE XXXII.

Deflection of Beams and Girders.

Resistance of Beams to Flexure—Examples I., II., III., and IV. —Thin Wrought-Iron Girders—Example V.—Curvature and Deflection of Beams—Example VI.—Uniform Beams on Three Supports—Uniform Beam fixed at one end and supported at the other—Beams fixed at both ends and loaded at centre—Beams fixed at both ends and loaded uniformly —Tables—Questions, ... 294-323

PART VI.—HYDRAULICS AND HYDRAULIC MACHINERY.

LECTURE XXXIII.

Hydrostatics—Hydraulic Machines.

Hydraulics—Fluids—Viscosity—Transmission of Pressure by a Fluid—Pressure of a Heavy Fluid—Head—Pressure on an Immersed Surface—Examples I., II., III., and IV.—Centre of Pressure—Centre of Pressure on a Rectangle—Triangle —Circle—Example V.—Energy of Still Water—Common Suction Pump—Belt-driven Suction Pump—Example VI. —Air Pump—Single-acting Force Pump—Single-acting Force Pump with Ball Valves—Force Pump with Air Vessel—Continuous Delivery Pumps without Air Vessels —Double-acting Force Pump—Double-acting Circulating Pump—Worthington Steam Pump—Pulsometer Pumps—Roots' Blower—Bramah's Hydraulic Press—Examples VII. and VIII.—Hydraulic Flanging Press—Hydraulic Jack—Examples IX., X., and XI.—Hydraulic Bear—Lead-covering Cable Press—Hydraulic Accumulator—Example XII.—Hydraulic Cranes—Hydraulic Wall Crane—Movable Jigger Crane—Double Power Hydraulic Crane—Hydraulic Capstan—Questions, ... 324-379

PAGES

LECTURE XXXIV.

Hydraulic Appliances in Gas Works.

Labour-Saving Appliances in Modern Gas Works—Pumping Engines and Accumulator—Example I.—Differential Accumulator—Brown's Steam Accumulator—Small Hydraulic Accumulator Plant—Arrol-Foulis Gas Retort Charging Machine—Foulis' Withdrawing Machine for Gas Retorts—Results of Working—Questions, ... 380-399

LECTURE XXXV.

Hydrokinetics.

Energy of Flowing Water—Bernouilli's Theorem—Jet Pumps, Injectors and Ejectors—Hydraulic Ram—Example I.—Velocity of Efflux and Flow of Water from a Tank—Measurement of a Flowing Stream—Rectangular Gauge Notch—Thomson's Triangular Notch—Measurement of Head—Measurement of Large Streams—Horse-power of a Stream—Vortex Motion—Free Vortex—Forced Vortex—Pressure due to Centrifugal Force—Reaction of a Jet—Reduction of Pressure Round an Orifice—Impact—Loss of Energy—Resistance of a Pipe—Hydraulic Mean Depth—Questions, 400-427

LECTURE XXXVI.

Water-Wheels and Turbines.

Hydraulic Motors—Overshot Water-Wheel—Breast-Wheels—Undershot Water-Wheels—Fairbairn's Improvements—Clack Mill—Pelton Wheel—Turbines—Girard Turbine—Jonval Turbine—Günther's Governor—Thomson's Vortex Turbine—Little Giant Turbine—Questions, . . 428-453

LECTURE XXXVII.

Refrigerating Machines.

Refrigeration—Preliminary Considerations—Carbon Dioxide as a Refrigerating Agent—Elementary Refrigerating Apparatus—Simple Refrigerating Machine—Carbon Dioxide Refrigerating Plant—Anhydrous Ammonia as a Refrigerating Agent—De La Vergne's Refrigerating Plant—De La Vergne's Double Acting Compressor—The Linde System of Refrigeration—Apparatus for Transmitting the cold produced to the Chambers requiring Refrigeration—Questions, . . 454-475

INDEX, ... 477

APPLIED MECHANICS.

VOLUME II.

PART III.—MOTION AND ENERGY.

LECTURE XX.

CONTENTS. — Definitions — Motion — Velocity — Acceleration — Graphical Methods—Velocity Diagrams—Falling Bodies—General Formulæ—Rotation—Angular Velocity—Circular Measure—Angular Acceleration — Composition and Resolution of Velocities — Parallelogram of Velocities—Triangle of Velocities—Polygon of Velocities—Rectangular Resolution—Composition and Resolution of Accelerations—The Hodograph—Hodograph for Motion in a Circle—Examples I., II., III., and IV.—Instantaneous Centre—Questions.

DEFINITION.—**A body is said to be in Motion when it is continually changing its position in space, and to be at Rest when it retains a fixed position in space.**

These are the definitions of *absolute* motion and *absolute* rest. We can never know the absolute motion of any body because we know no fixed bodies to which we may refer its positions at different times. We, therefore, can only deal with the *relative motion* of a body.

DEFINITION.—**A body is said to have Relative Motion with respect to another body when it is continually changing its position relatively to that body.**

Thus, take the case of a train moving on a railway. We always consider its motion relatively to some part of the earth's surface. But the train is carried round the earth's axis and also round the sun by the rotation of the earth itself. And this is not all, for we have reason to believe that the sun itself is not fixed in space but is in motion. A passenger in the train might be at rest relative to the train but he would be in motion relatively to the houses, trees, &c., which the train passed on its way.

Motions of Translation and Rotation.—The motion of a body may be either *Translatory* or *Rotary*.

A body is said to have a motion of *simple translation* when all points in the body move with the same velocity and in the same direction at the same instant, so that no line in the body changes its direction. Hence, the motion of the whole body is known when that of any point in it is known.

A body is said to have a motion of *simple rotation* when the various points in the body describe circles about some fixed axis either within or without the body. Hence, the motion of the whole is known when that of any *line* in the body (other than the axis about which the motion takes place) is known.

The motion of a body may be *complex;* being composed or compounded of motions of translation and rotation. Thus, the connecting-rod of an engine has a complex motion. It has a motion of translation in a vertical plane containing the centre line of the engine, and a motion of rotation in the same plane about the crosshead pin.

DEFINITION.—**The Path of a moving point is the line, straight or curved, which passes through all the successive positions of the point.**

Direction of Motion.—The direction of motion of a body is, at any particular instant, the tangent to the path of the body at that instant, or the path itself if the motion is rectilinear.

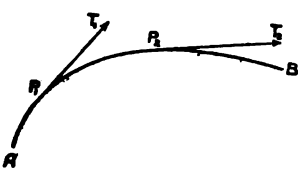

ILLUSTRATING DIRECTION OF MOTION.

Thus, let A B be the path of a moving body. When the body occupies the position, P_1, its direction of motion is along P_1, T_1, the tangent to the path at that point. Similarly, when the body occupies the position P_2, its direction of motion is along the tangent P_2, T_2.

Hence, when a body moves in a circular path its direction of motion at any instant will be perpendicular to the radius drawn to its position on the circle at that instant.

DEFINITION.—**The Velocity of a body is the rate at which it changes its position.**

A *velocity* is completely specified when we know (1) its *direction*, and (2) its *magnitude*.

Hence, a velocity can be completely represented by a straight line of finite length with a suitably-directed arrow head.

DEFINITION.—**A body is said to be moving with Uniform Velocity when it is moving in a constant direction and passes over equal distances in equal intervals of time, however small these may be.**

The last clause in the above definition is necessary, because a body *might* describe equal distances in equal times, and yet its motion might not be uniform. Thus, a train may describe 20 miles in each of two consecutive hours, and yet its motion may have varied continuously during that time; sometimes its velocity may be 60 miles an hour, and at other times it may be nil.

Uniform Velocity, how Measured.—When uniform, the velocity of a body is measured by its displacement in unit time. Thus:—

$$\text{Velocity} = \frac{\text{Displacement}}{\text{Time}}.$$

DEFINITION.—**A body is said to have Unit Velocity when it describes unit distance in unit time.**

The unit of distance in this country is the *foot*, and the unit of time is usually the *second*, although engineers often take the *minute*, or even the *hour*, as the unit of time. For example, the speed of a railway train is always spoken of as so many *miles per hour*, and that of the piston of an engine as so many *feet per minute*.

Whatever units may be used, we get:—

$$\left.\begin{aligned} v &= \frac{s}{t} \\ \text{Or,}\quad s &= v\,t \end{aligned}\right\} \quad \ldots\ldots\ldots\ldots \text{(I)}$$

Where, s = Displacement, or distance described, in time, t.

And, v = Velocity, supposed to be uniform.

*[From the above definition and equation it is evident that v must be the same however small t may be. Thus, let the displacement be very small, say Δs, then the time taken to describe it will be correspondingly small, say Δt, and we get:—

$$v = \frac{\Delta s}{\Delta t}.$$

This being true for the smallest fraction of time, it must also be true in the limit.

$$\left.\begin{aligned} \therefore\quad v &= \frac{d\,s}{d\,t} \\ \text{Or,}\quad d\,s &= v\,d\,t \end{aligned}\right\} \quad \ldots\ldots\ldots \text{(II)}\ ]$$

DEFINITION.—**A body is said to be moving with Variable Velocity when it is either changing its direction of motion or passing over unequal distances in equal intervals of time.**

* Students who have no knowledge of the notation of the *Calculus*, and those merely reading for examination in the Advanced Stage of this subject, may omit for the present the text within the brackets, thus [ ].

From this definition it appears that a body has a *variable velocity* when the direction or magnitude of its velocity is variable. Thus, a point on the rim of the flywheel of an engine has a variable velocity whether the rotary motion of the wheel be uniform or not.

This follows at once from the fact that a velocity is only completely specified when we know its *direction* and *magnitude*, and a change in either the direction or in the magnitude causes a change in the velocity. It is usual, however, in most problems, to speak of the velocity as being uniform or variable, according as the *magnitude* of the velocity is uniform or variable.

Variable Velocity, how Measured.—When variable, the velocity of a body is measured at any particular instant by the displacement which the body would have received if it moved for a unit of time with the same velocity which it had at the instant under consideration.

Thus, we see a train approaching a station and say that its velocity is 10 miles an hour, although we at the same time observe that its velocity is diminishing rapidly, and will soon be zero. By the expression "10 miles an hour" we, therefore, do not mean that it will run 10 miles during the next hour, but simply that *if* the train continued to run for one hour with the same speed that it had at the instant the remark was made, it would travel a distance of 10 miles.

Average Velocity.—When the velocity of a body is variable, and we know its magnitudes for several positions of the body, then its *average* velocity can be found in the same way as we find the average of a series of numbers.

Thus, let $v_1, v_2, v_3, \ldots v_n$ denote the velocities at n different points in its path; then :—

$$\text{Average velocity} = \bar{v} = \frac{v_1 + v_2 + v_3 + \ldots + v_n}{n}.$$

Or it may be defined as follows :—

DEFINITION.—**When a body moves through a certain distance with a variable velocity, its average velocity is that uniform velocity which it would require to have in order to traverse the same distance in the same time.**

$$\left.\begin{array}{ll} \text{Therefore,} & \bar{v} = \dfrac{s}{t} \\ \text{Or,} & s = \bar{v}\,t \end{array}\right\} \quad \ldots\ldots\ldots \quad (\mathrm{I}_a)$$

If the velocity increase or decrease uniformly, then the mean or average velocity is half the sum of the initial and final velocities.

$$\text{Or,} \qquad \bar{v} = \frac{v_1 + v_2}{2}. \quad \ldots\ldots\ldots \quad (\mathrm{III})$$

Where v_1 and v_2 denote the initial and final velocities respectively.

DEFINITION.—**The acceleration of a body is its rate of change of velocity.**

Acceleration may be either uniform or variable.

DEFINITION.—**Acceleration is uniform when equal changes of velocity take place in equal intervals of time, however small these may be.**

Otherwise, the acceleration is variable.

Acceleration, how Measured.—Uniform acceleration is measured by the change in the velocity in a unit of time.

Variable acceleration is measured at any particular instant by what would be the change of velocity in a unit of time, on the supposition that during that unit of time the acceleration remained the same as at the instant under consideration.

If the student thoroughly understands the method of measuring a variable velocity, he should have no difficulty in perceiving from the above statement how variable acceleration is measured.

Uniformly Accelerated Motion.—We shall now deduce the ordinary formulæ for the motion of a body uniformly accelerated in its line of motion.

Let v_1 = Velocity of body at end of time t_1,
" v_2 = " " " t_2,
" s = Distance described during interval $(t_2 - t_1)$,
" a = Acceleration per unit time.

Then, *Change of velocity* $= v_2 - v_1$.

$\therefore$ *Rate of change of velocity* $= \dfrac{v_2 - v_1}{t_2 - t_1}$.

But, *Rate of change of velocity* = *acceleration.*

$$\therefore \qquad a = \frac{v_2 - v_1}{t_2 - t_1}.$$

Or, denoting the interval of time $(t_2 - t_1)$ by t, we get:—

$$\left.\begin{aligned} a &= \frac{v_2 - v_1}{t} \\ \text{Or,} \qquad v_2 &= v_1 + a\,t \end{aligned}\right\} \quad . \quad . \quad . \quad . \quad \text{(IV)}$$

That is:—Final Velocity = Initial Velocity + Change of Velocity.

Again, since the acceleration is uniform, we get:—

$$\textit{Average velocity} = \frac{v_1 + v_2}{2}$$

$$\therefore \qquad s = \frac{v_1 + v_2}{2} \times t.$$

But, $$v_2 = v_1 + a\,t,$$

$$\therefore \qquad s = \frac{v_1 + (v_1 + a\,t)}{2} \times t,$$

Or, $$s = v_1\,t + \tfrac{1}{2}\,a\,t^2. \quad . \quad . \quad . \quad . \quad . \quad (\mathrm{V})$$

In many problems the time, t, is not given, and we require to find one of the four quantities, s, a, v_1, v_2, having given the other three. From equations (IV) and (V) the following relation between these quantities can easily be deduced by eliminating t. Thus:—

From equation (IV), $a = \dfrac{v_2 - v_1}{t}$,

From equation (V), $s = \dfrac{v_1 + v_2}{2} \times t$.

Multiplying together the corresponding sides of these equations and equating the products, we get:—

$$a\,s = \frac{v_2^2 - v_1^2}{2},$$

$$\left.\begin{aligned} \therefore \qquad v_2^2 - v_1^2 &= 2\,a\,s \\ \text{Or,} \qquad v_2^2 &= v_1^2 + 2\,a\,s \end{aligned}\right\} \quad . \quad . \quad . \quad . \quad . \quad (\mathrm{VI})$$

The above formulæ are true for all cases of *uniformly increasing* or *uniformly decreasing* velocity; but in the latter case, the acceleration will be negative, and a must be preceded by the *minus* sign.*

If the body start from rest, that is, if the time, t, be reckoned from the commencement of the motion, then, the initial velocity, $v_1 = 0$, and we get, from the above equations:—

$$v = a\,t \quad . \quad . \quad . \quad . \quad . \quad . \quad . \quad . \quad (\mathrm{IV}_a)$$

$$s = \tfrac{1}{2}\,a\,t^2 \quad . \quad . \quad . \quad . \quad . \quad . \quad . \quad . \quad (\mathrm{V}_a)$$

$$v^2 = 2\,a\,s \quad . \quad . \quad . \quad . \quad . \quad . \quad . \quad . \quad (\mathrm{VI}_a)$$

Where v = velocity at end of time, t.†

* There is no need for deducing, or even stating, the corresponding formulæ when the acceleration is negative. The fewer formulæ to be committed to memory the better, and the student should learn to distinguish between positive and negative (increasing or decreasing) acceleration as indicated by difference in sign, and to supply the proper sign where necessary.

† The general formulæ (IV), (V), and (VI) should be used in all cases. When the body starts from rest, substitute $v_1 = 0$.

Graphical Methods.—Equations (III) and (IV) can be very easily represented by means of a diagram. We may here remark that diagrams of velocities, accelerations, &c., are very useful in assisting the student to answer many problems on the motion of a body, and in what follows we shall have several instances of their use when dealing with the moving parts of engines. Before explaining the following diagrams, it is necessary to remind the student that a velocity, or an acceleration, can be completely represented by a straight line. We have already seen that a *velocity* may be represented by a finite straight line. But an *acceleration* is a change of velocity per unit time. Hence, an acceleration may also be represented by a finite straight line. In the meantime, we are not concerned with the *direction* of the velocity or acceleration, so that the lines representing these may be drawn in any convenient direction.

Velocity and acceleration diagrams are constructed in a way similar to those representing work, viz., by drawing two axes at right angles, along which the velocities or accelerations and intervals of time may be plotted.

Diagram for Uniform Velocity.—Let v = velocity, supposed to be uniform, and t = time. Draw the line A B, along which intervals of time have to be plotted. Thus, let A B represent t. From A, set up A C at right angles to A B, and let A C represent the velocity, v. Complete the rectangle A B D C. Then, clearly, the area of A B D C represents the displacement during the time, t. Thus:—



DIAGRAM FOR UNIFORM VELOCITY.

The area, A B D C, represents the displacement in time, t.

$$\therefore \quad s = v\,t.$$

$$\text{Displacement} = s = v\,t$$
$$= \text{area A B D C.}$$

Diagram for Uniformly Increasing Velocity.—Let a = the acceleration, and v = velocity at the end of time, t; the initial velocity being zero. As before, let A B represent the interval of time, t. At B, the end of interval t, draw B C to represent v, and join A C. Then, as before, the area of triangle A B C represents the displacement during time, t; since,

$$\textit{Displacement} = s = \textit{mean velocity} \times \textit{time} = \tfrac{1}{2}v \times t$$
$$\text{,,} \qquad = \tfrac{1}{2}\,\text{B C} \times \text{A B} = \text{area A B C.}$$

The velocity at any other time can be found by drawing the ordinate from the point on A B representing the given instant.

Thus, suppose A B represents 4 seconds. Then, the velocity at the end of 3 seconds from the beginning of the motion is represented by the ordinate 3 F. Similarly, at the end of the first second, the velocity is represented by the ordinate 1 D. But in this case, the velocity at the end of the first second is a measure of the acceleration; therefore, 1 D represents the acceleration.

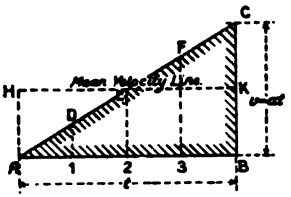

DIAGRAM FOR VELOCITY INCREASING UNIFORMLY FROM 0 TO v.

The area, A B C, represents the displacement in time, t.

$\because \quad s = \frac{1}{2} v t.$

If the acceleration be given instead of the final velocity, v, then the diagram can be set out in the following manner :—

Let A 1 represent a unit of time. Draw 1 D at right angles to A B to represent the acceleration, a. Then A C is the velocity line. From this it will be seen that $v = \text{B C} = a t$.

$$\therefore \quad s = \tfrac{1}{2} a t^2 = \tfrac{1}{2} a t \times t = \tfrac{1}{2} \text{B C} \times \text{A B} = \text{area A B C}.$$

Join A D and produce it.

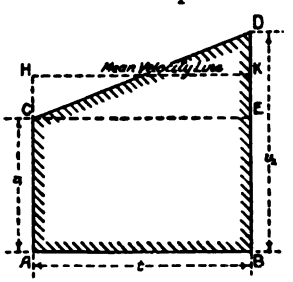

DIAGRAM FOR VELOCITY INCREASING UNIFORMLY FROM v_1 TO v_2.

The area, A B D C, represents the displacement in time, t.

$\because \quad s = v_1 t + \frac{1}{2} a t^2.$

If the body does not start from rest let the initial velocity be v_1, and the final velocity, v_2. Then, at each end of A B, the line representing t, draw the ordinates A C and B D to represent v_1 and v_2 respectively, and join C D.

Here, *Displacement* $= s = \frac{1}{2}(v_1 + v_2) \times t = \frac{1}{2}(\text{A C} + \text{B D}) \times \text{A B}$

" $= \text{area A B D C}.$

Also, $\text{E D} =$ *Change of velocity in time,* $t = a t$.

And, $\text{B D} = \text{B E} + \text{E D} = v_1 + a t$.

$$\therefore \quad s = \tfrac{1}{2}(v_1 + \overline{v_1 + a t}) \times t = v_1 t + \tfrac{1}{2} a t^2.$$

We have not drawn the corresponding diagrams for the case when the acceleration is *negative*, but the student should have

no difficulty in doing this for himself. Thus, when a is negative, the last diagram would be drawn with the velocity line sloping in the opposite direction.

Motion Due to Gravity.—The most familiar instance of uniformly accelerated motion is that of a body falling under the influence of gravity. Experiments show that if a body be allowed to fall freely in *vacuo* its motion will be uniformly accelerated, and this acceleration is the same for every body (large or small, heavy or light) at the same locality. The letter g is always used to denote this acceleration. Its value depends on the distance of the falling body from the centre of mass of the earth, and varies inversely as the square of this distance. Hence, g is different at different latitudes, being greatest at the poles and least at the equator. When the units of distance and time are the foot and the second, the value of g at the poles is about 32·255, and 32·091 at the equator. Its value at the sea level in the latitude of London is about 32·19, and is generally taken at 32·2 for any place in the British isles.

Formulæ for the motion of bodies under the action of gravity alone are derived from those previously given for uniformly accelerated motion by substituting g for a. Thus:—

(I) *When let fall without initial velocity.*

$$v = g\,t \quad \ldots\ldots\ldots\ldots \quad (\mathrm{IV}_b)$$

$$s = \tfrac{1}{2} g\,t^2 \quad \ldots\ldots\ldots\ldots \quad (\mathrm{V}_b)$$

$$v^2 = 2\,g\,s \quad \ldots\ldots\ldots\ldots \quad (\mathrm{VI}_b)$$

(II) *When let fall with initial velocity,* v_1.

$$v_2 = v_1 + g\,t \quad \ldots\ldots\ldots \quad (\mathrm{IV}_c)$$

$$s = v_1\,t + \tfrac{1}{2} g\,t^2 \quad \ldots\ldots\ldots \quad (\mathrm{V}_c)$$

$$v_2^2 = v_1^2 + 2\,g\,s \quad \ldots\ldots\ldots \quad (\mathrm{VI}_c)$$

If the body is thrown upwards with an initial velocity, v_1, then the acceleration due to gravity will be in the opposite direction to that of the motion; consequently, we must make *either* v_1 or g *negative*, according as we consider the downward or the upward direction to be *positive*. In such a case it is usual to make g negative. The rule usually observed is to take the acceleration *positive* or *negative* according as the motion is *increased* or *decreased*.

[**General Formulæ for Linear Motion.**—We have already seen that the velocity of a body is expressed generally as:—

$$v = \frac{d\,s}{d\,t}.$$

We can now give similar expressions for the acceleration when this varies according to any law whatever. Thus, at any instant of time let the velocity of the body be v, and at the end of an interval of time, Δt, let it be $v + \Delta v$, then :—

$$\textit{Acceleration} = \frac{\text{Change of velocity}}{\text{Time required}},$$

$$\text{,,} \quad = \frac{(v + \Delta v) - v}{\Delta t} = \frac{\Delta v}{\Delta t}.$$

This being true, however small Δt may be, it is, therefore, true in the limit, hence :—

$$a = \frac{dv}{dt}.$$

But,

$$v = \frac{ds}{dt},$$

$$\therefore \quad a = \frac{dv}{dt} = \frac{d^2 s}{dt^2}. \quad . \quad . \quad . \quad . \quad . \quad . \quad \text{(VII)}]$$

Body Rotating about an Axis.—Angular Velocity.—We have already said that the motion of a body rotating about an axis is completely known when that of any line in the body, other than the axis of rotation, is known. It is most convenient to take this line passing through the axis, and perpendicular to it. Thus, let O be the intersection of the axis with the plane of the paper, O P a line in the body perpendicular to the axis through O. Then the motion of the body is known when that of the line O P is known. The motion of the line O P is measured by the angle which it describes round the point, O, in unit time. This angle is then spoken of as the angular velocity of the body. Hence the following :—

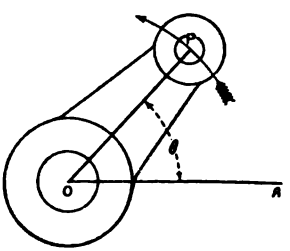

To illustrate Angular Velocity.

Definition.—**The angular velocity of a body about an axis is the rate of the angular displacement of any line in the body perpendicular to that axis.**

Angular velocity, like linear velocity, may be either *uniform* or *variable*, according as equal or unequal angles are described in equal intervals of time.

Uniform Angular Velocity.—Let the centre line, O P, of the crank in the above figure sweep out the angle, A O P = θ, in the interval of time, t; then the angular velocity of the body (usually denoted by the Greek letter ω) is :—

$$\omega = \frac{\theta}{t}. \quad . \quad . \quad . \quad . \quad . \quad . \quad . \quad . \quad \text{(VIII)}$$

The angle, θ, is measured in *circular units*, and not in degrees. The unit angle in circular measure is called the *radian*, and may be defined as *the angle subtended at the centre of a circle by an arc of its circumference, equal in length to the radius of the circle.* Hence, if t is in seconds, the *unit of angular velocity* will be the *radian per second*.

Since the length of the arc subtending a right angle is $\frac{\pi}{2} \times r$, and, therefore, the circular measure of a right angle equal to $\frac{\pi}{2}$ radians, we may easily determine the number of *degrees* in a radian. Thus :—

Degrees in 1 *radian* : *Degrees in* 1 *right angle* = 1 : $\frac{\pi}{2}$.

$$\therefore \qquad \text{Degrees in 1 radian} = \frac{90}{\frac{\pi}{2}} = \frac{180}{3{\cdot}1416} = 57{\cdot}29.$$

In general, if θ be the circular measure of an angle of $n°$, then :—

$$n° : 90° = \theta : \frac{\pi}{2},$$

Or,

$$\theta = \frac{n\pi}{180}.$$

Hence, if the angle described in time, t, by O P, be $n°$, we get:—

$$\omega = \frac{n\pi}{180\,t}. \quad . \quad . \quad . \quad . \quad \text{(VIII}_a\text{)}$$

When the *linear* velocity of any point, P, in the body, and its distance from the axis are known, the angular velocity of the body can be found. Thus :—

Let v = Component of linear velocity of P perpendicular to O P (see the previous figure).
" r = Radius, O P.
Then, v = Arc described by P in unit time.
$\therefore$ $\frac{v}{r}$ = Circular measure of angle described by O P in *unit time.*

$$\left.\begin{array}{ll} \textit{i.e.,} & \omega = \dfrac{v}{r} \\ \text{Or,} & v = \omega r \end{array}\right\} \quad \ldots\ldots\ldots \quad \text{(IX)*}$$

Variable Angular Velocity.—Angular Acceleration.—When the angular velocity is variable, it is measured in a way similar to that of variable linear velocity.

[Let $\Delta\theta$ = small angle described by O P, in small interval of time, Δt; then we have :—

$$\omega = \frac{\Delta\theta}{\Delta t},$$

which, in the limit, becomes :—

$$\omega = \frac{d\theta}{dt}. \quad \ldots\ldots\ldots \quad \text{(X)]}$$

DEFINITION.—**The angular acceleration of a rotating body is the rate of change of its angular velocity.**

Angular acceleration may be either *uniform* or *variable* according as equal changes of angular velocity take place in equal or unequal intervals of time. When uniform, angular acceleration is measured by the increase or decrease of angular velocity per unit time.

Let ω_1, ω_2 = Angular velocities at the beginning and end of interval of time, t.

" θ_1, θ_2 = Angular displacements at the beginning and end of interval of time, t.

" α = Angular acceleration.

$$\left.\begin{array}{ll} \text{Then,} & \alpha = \dfrac{\omega_2 - \omega_1}{t} \\ \text{Or,} & \omega_2 = \omega_1 + \alpha t \end{array}\right\} \quad \ldots\ldots\ldots \quad \text{(XI)}$$

From these equations and those previously deduced for uniformly accelerated linear motion, the student will notice the similarity of the relations between the terms s, v, and a, and θ, ω, and α respectively.

Hence, we get the remaining and corresponding equations for rotary motion, viz. :—

$$\theta = \omega_1 t + \tfrac{1}{2}\alpha t^2 \quad \ldots\ldots\ldots \quad \text{(XII)}$$

$$\omega_2^2 = \omega_1^2 + 2\alpha\theta. \quad \ldots\ldots\ldots \quad \text{(XIII)}$$

* It is sometimes convenient to speak about the angular velocity of a *point*, such as P in the foregoing figure. Such a phrase is not strictly correct, and when used, it should be understood to mean the angle described in unit time by the radius drawn through the point, P.

[Generally, we have:—

$$\alpha = \frac{d\omega}{dt} = \frac{d^2\theta}{dt^2} \quad . \quad . \quad . \quad . \quad . \quad . \quad . \quad . \quad \text{(XIV)}]$$

Composition and Resolution of Velocities.—A moving body may have at any instant two or more velocities in different directions, and it then becomes an important problem to be able to determine the resultant velocity, both in magnitude and in direction. Thus, the magnitude and direction of the motion of a man who walks across the deck of a moving ship is different from that of the ship and also from that of his motion relative to the deck. Similarly, the motion of a point on the rim of a carriage wheel in motion is, in general, different in magnitude and direction from its circular motion about the axle, and also from the onward motion of the wheel as a whole.

The process of finding a single velocity equivalent in effect to two or more velocities is called the *Composition of Velocities.*

The process of finding two or more velocities equivalent in effect to a single velocity is called the *Resolution of Velocities.*

DEFINITIONS.—**The single velocity which is equivalent to two or more velocities is called their Resultant, and these two or more velocities are called the Components.**

Parallelogram of Velocities.—If two component velocities be represented, in magnitude and direction, by two adjacent sides, O A, O B, of a parallelogram, their resultant velocity will be represented by the diagonal, O D, through their intersection.

Thus, if a moving point, O, possess simultaneously two velocities, P and Q, in directions O A and O B respectively, and, if O A and O B represent the magnitudes of these velocities, their resultant velocity, R, will be represented both in magnitude and in direction by the diagonal, O D, of the parallelogram constructed on O A, and O B, as adjacent sides.

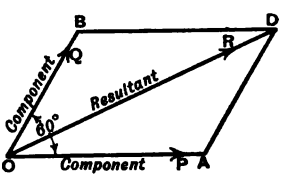

PARALLELOGRAM LAW.

Let θ = angle between the directions of the velocities, P and Q.

" $\alpha = \angle$ A O D, and $\beta = \angle$ B O D, the angles between the direction of the resultant, R, and the components P and Q respectively.

Then the student may easily prove from Euclid II., 13 and 14, or by trigonometry, that:—

$$R^2 = P^2 + Q^2 + 2\,P\,Q \cos\theta. \quad . \quad . \quad . \quad (XV)$$

$$\left.\begin{aligned} \text{And,} \qquad \tan\alpha &= \frac{Q \sin\theta}{P + Q\cos\theta} \\ \text{Or,} \qquad \tan\beta &= \frac{P \sin\theta}{Q + P\cos\theta} \end{aligned}\right\} \quad . \quad . \quad . \quad . \quad . \quad . \quad . \quad (XVI)$$

From these equations the magnitude and direction of the resultant velocity can be calculated.

It is not necessary to complete the parallelogram as explained above, it being quite sufficient to draw but one-half of the figure. Thus, A D is equal and parallel to O B; hence, as much can be determined from the triangle, O A D, as from the complete parallelogram, O A D B.

Triangle of Velocities.—If two component velocities be represented in magnitude and direction by two sides of a triangle taken in order, their resultant will be represented in magnitude and direction by the third side taken in the reverse direction.

Hence, if there be simultaneously impressed on a point three velocities represented in magnitude and direction by the sides of a triangle taken in order, then the point will remain at rest.*

Polygon of Velocities.—If several component velocities be represented by all but one of the sides of a polygon, A B C D E F, taken in order —the resultant velocity will be represented in magnitude and direction by the remaining side, A F, taken in the opposite direction.

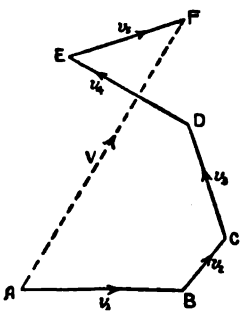

POLYGON OF VELOCITIES.

Thus, if a moving point have simultaneously impressed upon it velocities, v_1, v_2, . . v_5, and these are represented in magnitude and direction by the sides A B, B C, . . . E F of a polygon, A B C D E F, then the resultant velocity will be represented in magnitude and direction by the side, A F, required to complete the polygon.

* In setting out the *Parallelogram*, or *Triangle of Velocities*, it is not necessary to draw the sides parallel to the velocities represented. The sides may be drawn in directions *perpendicular* to the respective velocities, or, indeed, at any other angle, so long as the angle is the same for all the sides. In such cases the line representing the resultant will be equally inclined to its true direction.

If the figure whose sides represent the component velocities be closed or completed when the last velocity has been represented, then there is no resultant velocity, and the point will remain at rest.

It is equally important to be able to *resolve* a given velocity into two or more component velocities. Thus, the velocity, R (see the figure for *Parallelogram of Velocities*), can be resolved into two components, P and Q, in the directions O A, O B respectively. Or, the velocity, V (in the last figure), may be resolved into a number of components, $v_1, v_2, \ldots$, in directions A B, B C, . . . Further, the directions of the component velocities may be anything we like. Thus, in resolving a given velocity, R, into two components, we can do so in an infinite number of ways, since an infinite number of parallelograms, such as O A D B, can be found having O D for one of their diagonals. When, however, the *directions* of the components are fixed, their magnitudes will be definite and easily determined. Referring to the figure for the *Parallelogram of Velocities*, let O D represent a velocity, R, which has to be resolved into two components in the directions O A and O B. From D draw D A parallel to B O and D B parallel to A O, meeting the lines O A and O B in the points A and B respectively. Then O A and O B represent the component velocities P and Q to the same scale that O D represents the velocity R.

The most important case of resolution is that wherein the given velocity has to be resolved into components whose directions are at right angles to each other. Thus, let it be required to resolve the velocity, v, whose direction is O C, into its Rectangular Components along O x and O y.

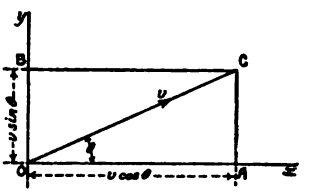

RECTANGULAR RESOLUTION.

From C drop the perpendiculars C A, C B on the axes O x and O y. Then, O A, O B are the components in the required directions.

Let v_x, v_y = Components of v in directions O x, O y respectively.
" θ = Angle between the directions of v and v_x.

Then, $v_x = v \cos \theta$
And, $v_y = v \sin \theta$ . . . . . (XVII)

Composition and Resolution of Accelerations.—Since an *acceleration* is a *rate of change of velocity*, whether in *magnitude* or in *direction*, it follows that accelerations may be compounded or resolved according to the same rules as velocities.

If the direction of motion of a body be constant, then change of velocity can only take place in that direction. Thus, if a body is constrained to move in a rectilinear path its only acceleration is one of magnitude, and takes place along the straight line in which the body moves.

Again, the velocity of a body may be constant in *magnitude*, but variable in *direction*, as in the case of a body moving with uniform speed in a circle. Or, it may vary both in magnitude and in direction, as in the case of the bob of a pendulum swinging to and fro. The **Total Acceleration**, in any case, may be found in the following manner:—

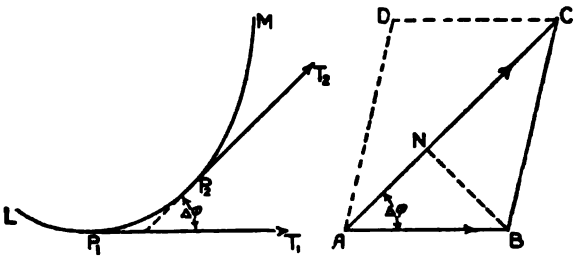

TOTAL ACCELERATION OF A MOVING BODY.

Let L M be the path of a moving body, and P_1, P_2 its positions at the beginning and end of an interval of time, t.

At P_1, its velocity is in the direction of the tangent, $P_1 T_1$, and at P_2, its velocity is in the direction, $P_2 T_2$.

From A draw A B and A C to represent in magnitude and direction the velocities of the body at the points P_1 and P_2 respectively. Join B C, and complete the parallelogram, A B C D. Then A C represents the resultant velocity whose components are A B and A D or B C. But, if the velocity of the body had remained constant in magnitude and in direction during the time, t, its velocity at the end of that interval of time would have been represented by A B. Hence, in the above case, A D, or B C, represents, in magnitude and direction, the *change of velocity* during the time, t.

$$\therefore \qquad \textbf{Total acceleration} = \frac{\text{B C}}{t}.$$

[Suppose the arc $P_1 P_2$ to be very small; and

Let v = Velocity of body at point, P_1.

,, $v + \Delta v$ = Velocity of body at point, P_2.

,, Δt = Small interval of time required to traverse the small arc, $P_1 P_2$.

,, $\Delta \varphi$ = Angle between tangents to curve at P_1 and P_2.

From B draw B N perpendicular to A C. Then B N and N C represent respectively the components of the total acceleration, B C, along lines normal and tangential to the curve at a point near to P_1.

Hence, *Normal Acceleration* = limit of $\frac{BN}{\Delta t}$

And, *Tangential Acceleration* = limit of $\frac{NC}{\Delta t}$.

Now, $BN = AB \sin \Delta \varphi = v \sin \Delta \varphi$.

$\therefore$ Limit of $\frac{BN}{\Delta t} = v \frac{d\varphi}{dt}$.

In the limit, let ds denote the infinitesimally small arc, $P_1 P_2$, and let ρ denote the radius of curvature at the point, P_1 or P_2.

Then, $$v \frac{d\varphi}{dt} = v \frac{ds}{dt} \cdot \frac{d\varphi}{ds} = v^2 \frac{d\varphi}{ds}.$$

But, from the properties of plane curves, we know that :—

$$\frac{d\varphi}{ds} = \frac{1}{\rho}.*$$

$\therefore$ **Normal Acceleration** $= \frac{v^2}{\rho}$. . . . (XVIII)

Again, Limit of $\frac{NC}{\Delta t}$ = limit of $\frac{\Delta v}{\Delta t} = \frac{dv}{dt}$.

$\therefore$ **Tangential Acceleration** $= \frac{dv}{dt}$. . . . (XIX)

The result expressed in equation (XIX) agrees with the corresponding general equation previously deduced.

In the case of a body moving in a circle with uniform motion, we get $\rho = r$ = radius of circle, and v is constant. Then the tangential acceleration is *nil*, and the

Normal or Radial Acceleration $= \frac{v^2}{r}$. (XVIII$_a$)

This is usually spoken of as the *Centripetal Acceleration.*]

The Hodograph—Uniform Motion in a Circle.—We shall now extend the foregoing principles to the determination of the acceleration of a body which moves with uniform velocity in a circle. In the first place we shall briefly describe the properties of the *Hodograph.*

* See Todhunter's *Diff. Calculus*, p. 343.

DEFINITION.—**If a point, P, be moving in any manner in a straight or curved path, and if from a fixed point, straight lines be drawn representing in magnitude and direction the velocities of P at different points of its path, the locus of the extremities of those lines will be a curve which is the Hodograph of P's motion.**

Thus, let L M be the path of a moving point, P. Let the velocities at the points P_1, P_2, P_3 . . . be v_1, v_2, v_3 . . . From any point, O, draw $O\,Q_1$, $O\,Q_2$, $O\,Q_3$ . . . respectively parallel to v_1, v_2, v_3 . . . and of lengths representing these velocities. Then the curve, Q_1, Q_2, Q_3, Q_4, which is the *locus* of

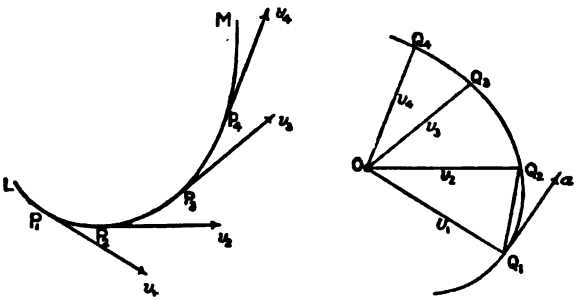

THE HODOGRAPH.

the point Q, is the hodograph of P's motion in the path, L M. Hence, to every point on the curve, L M, there will be a corresponding point on the hodograph, so that while the body describes the curve, L M, we may imagine a point to describe the hodograph.

We shall now prove the following property of the hodograph:—

The acceleration of the body at any point on the curve, L M, is represented in magnitude and direction by the velocity of the corresponding point on the hodograph.

Let v = Average velocity between P_1 and P_2.
,, Δt = Indefinitely small time required to describe arc $P_1\,P_2$.

Then, $$v = \frac{P_1\,P_2}{\Delta t}.$$

But $O\,Q_1$, $O\,Q_2$, represent the velocities of the body at the beginning and end of the interval of time, Δt. Therefore, chord $Q_1\,Q_2$ represents the *change of velocity* of the body, during that interval of time.

That is, $$\left.\begin{array}{c}\textit{Acceleration of body between}\\ P_1 \textit{ and } P_2\end{array}\right\} = \frac{Q_1\,Q_2}{\Delta t}.$$

But, in the limit, when P_2 approaches indefinitely near to P_1, and, therefore, also Q_2 approaches indefinitely near to Q_1, we get:—

$$\text{Chord } Q_1 Q_2 = \text{Arc } Q_1 Q_2.$$

But, $$\frac{\text{Arc } Q_1 Q_2}{\Delta t} = \textit{Velocity of } Q \textit{ in hodograph.}$$

$$\therefore \left.\begin{array}{l}\text{Acceleration of}\\ \text{body in curve}\\ \text{L M}\end{array}\right\} = \text{Velocity of Q in hodograph.}$$

Again, since the direction of motion of a point on a curve is along the tangent to the curve at that point, so the direction of motion of Q on the hodograph at any point is along the tangent to the hodograph at that point. Hence, the *direction* of the acceleration of the moving body at any point on the curve, L M, is represented by the tangent at the corresponding point on the hodograph.

Thus, let P_1 and Q_1 be corresponding points on the path and hodograph respectively. Then, $O Q_1$ represents the velocity of the body at P_1, and the tangent to the hodograph at Q_1 represents the *direction* of the acceleration at the same point.

When a body describes a circle with uniform velocity, it is evident that there can be no tangential acceleration.

Let A P B represent the circular path of a body moving with uniform velocity, v. Then, it is clear that the hodograph of the moving body will also be a circle whose radius is v. With centre, O, and radius representing v, describe a circle, C Q D. Then, circle C Q D is the hodograph. Let P be the position of the body at any instant. Draw the radius, O Q, of the hodograph parallel to the tangent at P; or, what is the same thing, draw O Q perpendicular to O P. Since the radius, O P, describes equal angles in equal times, it follows at once that the radius, O Q, of the hodograph will also describe equal angles in equal times. In other words, the velocity of Q in the hodograph is uniform. Now, the magnitude and direction of the *velocity* of Q represent the magnitude and direction of the *acceleration* of P. Therefore, the direction of the acceleration of P is that of the tangent to the hodograph at the point, Q; that is, it

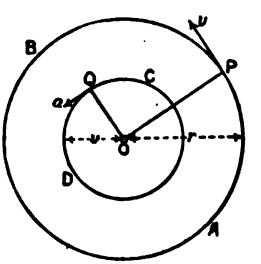

HODOGRAPH FOR UNIFORM MOTION IN A CIRCLE.

is along the radius, P O. As to the magnitude of this acceleration, we observe that:—

$$\textit{Acceleration of } P = a = \textit{Velocity of } Q.$$

Since Q describes the circle, C Q D, in the same time, t, as P describes the circle, A P B, we get:—

$$\text{For hodograph,} \quad t = \frac{\textit{Circumference of } C\,Q\,D}{\textit{Velocity of } Q} = \frac{2\pi \times v}{a} \quad . \quad (1)$$

$$\text{For Path of P,} \quad t = \frac{\textit{Circumference of } A\,P\,B}{\textit{Velocity of } P} = \frac{2\pi \times r}{v} \quad . \quad (2)$$

Equating (1) and (2) we get:—

$$\frac{2\pi v}{a} = \frac{2\pi r}{v}.$$

$$\therefore \quad \text{Acceleration of P} = a = \frac{v^2}{r}. \quad . \quad . \quad . \quad . \quad . \quad . \quad . \quad . \quad (XX)$$

EXAMPLE I.—A body slides down a smooth inclined plane, determine its velocity at the foot of the plane. If the plane has

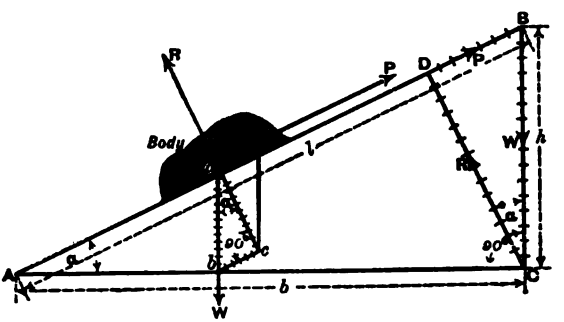

MOTION ON SMOOTH INCLINED PLANE.

a rise of 25 per cent., what distance would a body, descending along it from a state of rest, describe in five seconds? Find also the time occupied in sliding down the first 50 feet of the length of the plane.

ANSWER.—Let a = Acceleration of the body along the plane.
" α = Inclination of plane to the horizon.

(1) If the body were free to move vertically downwards its acceleration in that direction would be g. But since it is con-

strained to move in the direction B A, its acceleration in this direction will be less, being, in fact, the component of g, along B A.

Hence, resolve g into its rectangular components in directions along and at right angles to B A. Then :—

$$\textit{Acceleration along } \mathrm{B\,A} = g \sin \alpha.$$

$$\textit{Acceleration perpendicular to } \mathrm{B\,A} = g \cos \alpha.$$

The latter component has no effect on the motion of the body. Hence :—

$$\text{Acceleration down the plane} = a = g \sin \alpha. \quad . \quad . \quad (1)$$

Let t = Time required to slide along a length, s.
,, v = Velocity at the end of time, t.

Then, from equation (IV_a) $v = a\,t$.

$$\therefore \qquad v = g\,t \sin \alpha. \quad . \quad . \quad . \quad . \quad . \quad . \quad . \quad (2)$$

From equation (V_a) $\quad s = \frac{1}{2} a\,t^2$.

$$\therefore \qquad s = \tfrac{1}{2} g\,t^2 \sin \alpha. \quad . \quad . \quad . \quad . \quad . \quad . \quad (3)$$

And from equation (VI_a) $v^2 = 2\,a\,s$.

$$\therefore \qquad v^2 = 2\,g\,s \sin \alpha.$$

But, $\quad s \sin \alpha$ = Height of plane of length, s,
, = h, say.

$$\text{Then,} \qquad v^2 = 2\,g\,h. \quad . \quad . \quad . \quad . \quad . \quad . \quad . \quad . \quad (4)$$

That is,—*The velocity acquired by a body in sliding down a smooth inclined plane is the same as that acquired by a body falling freely through a distance equal to the height of the plane.*

From the given data, we get :—

$$\sin \alpha = \frac{25}{100} = \cdot 25,$$

$$t = 5 \text{ seconds.}$$

∴ From equation (3), we get :—

$$s = \tfrac{1}{2} g\,t^2 \sin \alpha = \tfrac{1}{2} \times 32{\cdot}2 \times 5 \times 5 \times \cdot 25$$

$$,, = 100{\cdot}625 \text{ feet.}$$

(2) Here, s = 50 feet, and we require t.
From equation (3), we get :—

$$s = \tfrac{1}{2} g\,t^2 \sin \alpha.$$

$$\therefore \qquad t = \sqrt{\frac{2\,s}{g \sin \alpha}} = \sqrt{\frac{2 \times 50}{32{\cdot}2 \times \cdot 25}} = 3{\cdot}52 \text{ seconds.}$$

EXAMPLE II.—State the rule for the composition of two velocities. If a particle describes the perimeter of a regular polygon with a constant velocity, v, show that there must be impressed on it, at each angular point a velocity equal to $2\,v \cos \alpha$, directed towards the centre of the circumscribing circle, where α denotes half an angle of the polygon. (S. & A. Hons. Theor. Mechs. Exam., 1885.)

ANSWER.—For answer to first part, see *Parallelogram of Velocities.* Let A B C D . . represent the sides of a regular polygon, whose centre is O. When the particle arrives at B, its direction of motion is suddenly changed from A B to B C, while the magnitude of the velocity remains unaltered. To find the magnitude and direction of the velocity which must have been imparted to the particle at the point, B, we may proceed as follows:—

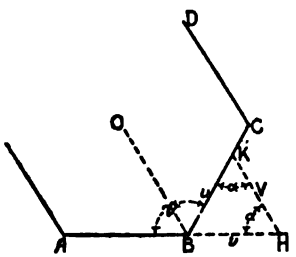

TO ILLUSTRATE EXAMPLE IV.

Produce A B, and set off B H, to represent the velocity, v, of the particle along A B, and B K along B C, to represent the velocity in that direction. Then H K represents in magnitude and direction the change of velocity which must have been imparted to the particle at the point, B. The magnitude of this velocity can be found from the triangle, B H K, or equation (XV).

For, $V^2 = v^2 + v^2 - 2\,v^2 \cos(180^\circ - 2\,\alpha) = 2\,v^2(1 + \cos 2\,\alpha)$

$\quad\quad\quad

ANSWER.—Take any point, P, on the rim of the wheel, and let the radius, drawn through P, make an angle, θ, with the vertical radius, O A.

Then, since the centre of the wheel is moving with velocity, v, it follows that the tangential velocity of any point on the rim is also v. This is, however, but one of the components of the actual velocity of P. The actual velocity of P is the resultant of two velocities—viz., v, along the tangent at P, and v, horizontally, since the point, P, in addition to moving round O, as a centre, is also being carried in a horizontal direction along with the wheel as a whole. By completing the parallelogram of velocities, as shown, the resultant velocity, V, can be found. The angle between the component velocities is $180° - \theta$. Hence, from equation (XV):—

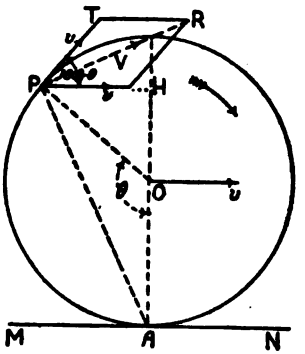

VELOCITY OF A POINT ON A ROLLING WHEEL.

$$V^2 = v^2 + v^2 + 2\,v^2 \cos(180° - \theta).$$

$$\therefore \qquad ,, \quad = 2\,v^2\{1 + \cos(180° - \theta)\} = 4\,v^2 \sin^2 \frac{\theta}{2}.$$

$$\therefore \qquad V = 2\,v \sin \frac{\theta}{2}. \quad \ldots \ldots \ldots \ldots \quad (1)$$

Next, as to the direction of the resultant velocity, V.
Since P R bisects the angle between P T and P H,

$$\therefore \qquad \angle RPH = 90° - \frac{\theta}{2}.$$

But, $\qquad \angle OAP = \frac{1}{2}\angle POH = 90° - \frac{\theta}{2}.$

$\therefore \qquad \angle RPH = \angle OAP.$

In the $\triangle$ A P H, $\angle$ O A P = complement of $\angle$ A P H.

$\therefore \qquad \angle RPH =$,, ,,

$\therefore \qquad \angle RPA$ is a right angle.

Hence, the direction of motion of P is perpendicular to the line joining P with A, the point of the wheel which is in contact with the ground.

The point, A, is called the **Instantaneous Centre** of motion for all points on the rim of the wheel; because any point, such as P, is moving at any instant on the circumference of a circle having A for its centre and A P as its radius.

The direction of the actual motion of any point, P, is, at any instant, inclined to the horizontal at an angle equal to $90° - \frac{\theta}{2}$.

EXAMPLE IV.—In the previous example find the magnitude and direction of the actual velocity of the point, P, when the radius, O P, makes angles of 0°, 90°, 180°, and 270° with the vertical radius, O A. Also, find the position of P when the resultant velocity, V, is equal to v.

ANSWER.—(1) *When* $\theta = 0°$. From equation (1), Example III., we get :—

$$V = 2\,r \sin\frac{\theta}{2} = 0, \text{ since } \sin 0° = 0.$$

i.e., the point is at rest when it is in contact with the ground A.

(2) *When* $\theta = 90°$. Here $\sin\frac{\theta}{2} = \sin 45° = \frac{\sqrt{2}}{2}$.

$$\therefore \qquad V = 2\,v \sin\frac{\theta}{2} = 2\,v \times \frac{\sqrt{2}}{2} = v\sqrt{2}.$$

Also, $\left.\begin{array}{l}\text{Direction which}\\ \text{V makes with}\\ \text{the horizon}\end{array}\right\} = 90° - \frac{\theta}{2} = 45°.$

(3) *When* $\theta = 180°$. $\sin\frac{\theta}{2} = \sin 90° = 1$.

$$\therefore \qquad V = 2\,v \sin\frac{\theta}{2} = 2\,v \times 1 = 2\,v.$$

And, $\left.\begin{array}{l}\text{Direction which}\\ \text{V makes with}\\ \text{the horizon}\end{array}\right\} = 90° - \frac{\theta}{2} = 0°.$

That is, when P is vertically over O, it is moving horizontally with a velocity equal to twice the speed of the wheel.

(4) *When* $\theta = 270°$. $\sin\frac{\theta}{2} = \sin 135° = \frac{\sqrt{2}}{2}$.

$$\therefore \qquad V = 2\,v \sin\frac{\theta}{2} = 2\,v \times \frac{\sqrt{2}}{2} = v\sqrt{2}.$$

And, $\left.\begin{array}{l}\text{The inclination}\\ \text{of V to the}\\ \text{horizon}\end{array}\right\} = 90° - 135° = -45°.$

(5) *To find θ when* $V = v$.

Here. $$V = 2\,v \sin\frac{\theta}{2}.$$

$\therefore$ $$\sin\frac{\theta}{2} = \frac{V}{2\,v} = \tfrac{1}{2}.$$

$\therefore$ $$\frac{\theta}{2} = 30^\circ, \text{ or } 150^\circ,$$

$\therefore$ $$\theta = 60^\circ, \text{ or } 300^\circ.$$

These agree with the two positions of P when the chord, A P, is equal to the radius, O A.

LECTURE XX.—QUESTIONS.

1. Define the terms velocity and acceleration, and explain how these are measured—(1) when uniform; (2) when variable. Give examples of bodies having accelerations—(*a*) constant in magnitude and direction; (*b*) constant in magnitude but not in direction; (*c*) constant in direction but not in magnitude; (*d*) variable both in magnitude and direction.

2. When the velocity of a particle is uniformly accelerated, show that $s = \frac{1}{2} a t^2$. A particle moves from a state of rest under the action of a force which increases its velocity by 20 feet per second in every second of its motion. After four seconds the force ceases to act on it. What distance does it describe in the first six seconds of its motion? (S. & A. Adv. Theor. Mechs. Exam., 1880.) *Ans.* 320 feet.

3. Establish the formulæ for uniform acceleration in the direction of motion:—$v_2 = v_1 + a t$; $s = v_1 t + \frac{1}{2} a t^2$, and from these results deduce the formula—$v_2^2 = v_1^2 + 2 a s$. Find an expression for the distance described in the nth second.

4. A cage is ascending the shaft of a mine at a uniform rate of 10 feet per second. When it is 50 feet from the top the speed is diminished, so that it now moves with a uniformly retarded velocity, and finally comes to rest at the top. Find the retardation. *Ans.* 1 foot per second.

5. State the rule for the composition of two velocities. Draw two lines, A B, A C, containing an acute angle. A particle is at A moving with a given velocity, V, from A towards B. Give a construction for determining the velocity that must be impressed on it, to make it move with a velocity, 2V, from A towards C. (S. & A. Adv. Theor. Mechs. Exam., 1894.)

6. A particle describes the perimeter of a regular hexagon with a constant velocity of 100 feet a second. Find the magnitude and direction of the velocity that must be communicated to it, at the instant it reaches an angular point. (S. & A. Adv. Theor. Mechs. Exam., 1889.) *Ans.* 100 feet per second towards centre of hexagon.

7. Two bodies start together from rest, and move in directions at right angles to each other. One moves with a uniform velocity of 3 feet per second, while the motion of the other is uniformly accelerated. At the end of four seconds the bodies are found to be 20 feet apart. Determine the acceleration of the latter body. *Ans.* 2 feet per second.

8. Two bodies, P and Q, move with different velocities along the same line. What is the relative velocity of Q to P? If Q is allowed to fall freely, and two seconds after P is allowed to fall freely from the same point, find the relative velocity of Q to P at any subsequent time. (S. & A. Adv. Theor. Mechs. Exam., 1893.) *Ans.* 64·4 feet per second.

9. Define angular velocity. P is a point of a body turning uniformly round a fixed axis, and P N is a line drawn from P at right angles to the axis. If P N describes an angle of 375° in three seconds, what is the angular velocity of the body? and if P N is 6 feet long, what is the linear velocity of P? (S. & A. Adv. Theor. Mechs. Exam., 1892.) *Ans.* (1) $0{\cdot}7\,\pi$ radians per second; (2) $4{\cdot}2\,\pi$ feet per second.

10. A point is describing a circle of radius 21 feet, with a uniform velocity of 12 feet per second. Find the change in its velocity after it has described

one-sixth of a whole circumference. *Ans.* 12 feet per second, at 120° with first direction.

11. A wheel, whose diameter is 5 feet, turns forty times a minute; find its angular velocity and the linear velocity of a point on its circumference. If the centre of the wheel moves in a straight line with a velocity of 20 miles an hour; what are the velocities, relative to a very distant fixed point in the straight line, of the ends of the diameter which is at any instant vertical? (S. & A. Adv. Theor. Mechs. Exam., 1884.) *Ans.* (1) $\omega = \frac{4\pi}{3}$ radians per second; (2) 10·5 feet per second; (3) upper end = 40 miles per hour; lower end = zero.

12. What is the numerical value of the angular velocity of a body which turns uniformly round a fixed axis twenty-five times a minute? A B C is a triangle right angled at C. It is turning with a given angular velocity, ω, round an axis through A, at right angles to its plane. Find the magnitude and direction of the velocities of B and C; and also the relative velocity of B to C. (S. & A. Adv. Theor. Mechs. Exam., 1892.) *Ans.* $\frac{5}{6}\pi$ radians per second.

13. A train descending a gradient increases its speed from 40 to 49 miles per hour in four and a-half minutes. Find the mean acceleration. Taking the acceleration due to gravity at 32 in feet and seconds, determine the gradient. *Ans.* (1) 0·049 foot per second per second, or 120 miles per hour per hour; (2) 1 in 654.

14. Given the base, b, of a smooth inclined plane, find its height, h, so that the horizontal component of the velocity of a body at the foot of the plane shall be a maximum. *Ans.* $h = b$.

15. Define the hodograph, and prove that the acceleration of a point's motion is equal to the velocity with which the hodograph is traced out. Determine, by means of the hodograph, the acceleration of a body which moves with uniform velocity in a circle.

16. Define the angular velocity of a moving point with respect to a fixed point. Under what circumstances will the angular velocity of the moving point be equal to its linear velocity divided by its distance? Draw an equilateral triangle A B C, having each side 12 feet long; a point moves along B C with a velocity of 10 feet a second; when it is at C, what is its angular velocity with respect to A? (S. & A. Adv. Theor. Mechs. Exam., 1896.)

17. Two circles touch each other externally, and the point of contact (A) is in the same vertical line as the centres; from any point (P) of the upper circumference draw a straight line P A Q to meet the lower circumference in Q; if a particle is allowed to fall from P along P Q, show that the time it takes to reach Q is constant for all positions of P. Also compare the times in which P A and A Q are described. (S. & A. Adv. Theor. Mechs. Exam., 1896.)

LECTURE XXI.

CONTENTS.—Quantity of Motion—Definition of Momentum—Example I.—Newton's Laws of Motion—Examples II. and III.—Motion on a Double Inclined Plane—Examples IV. and V.—Energy—Definition of Energy—Definitions of Potential and Kinetic Energy—Expression for Kinetic Energy—Energy Equations—Examples VI., VII., and VIII.—Questions.

Quantity of Motion.—In the preceding Lecture we have confined our attention chiefly to cases of pure motion—that is, motion considered apart from mass and force. In this Lecture we shall treat of the motion of bodies as produced by the action of external forces, and establish the relations between the *quantity of motion* thus produced and the magnitude of the forces producing it. **Quantity of motion** is measured by the product of the *mass* and its *velocity*. The term **Momentum** is used instead of *Quantity of motion*, and hence we get the following:—

DEFINITION.—**The momentum of a moving body is the product of its mass and velocity.**

Thus, let m be the mass, and v the velocity of a body:—

Then, **Momentum** $= m\,v$.

EXAMPLE I.—Of two steam hammers, one weighs 5 tons and the other 10 tons. The former has a drop of 10 feet and the latter 6 feet. Compare their momenta at the end of their respective strokes.

ANSWER.—In order to find their velocities at the moment of impact, we may employ formula (VI_b) of Lecture XX.:—

$$v^2 = 2\,g\,s,$$

$\therefore$ for the first hammer, $v_1 = \sqrt{2 \times 32 \times 10} = 8\sqrt{10}$ ft. per sec.

And, for the second hammer, $v_2 = \sqrt{2 \times 32 \times 6} = 8\sqrt{6}$ „

$$\therefore \left.\begin{array}{c}\text{Momentum of}\\ \text{first hammer}\\ \hline \text{Momentum of}\\ \text{second hammer}\end{array}\right\} = \frac{m_1 v_1}{m_2 v_2} = \frac{5 \times 8\sqrt{10}}{10 \times 8\sqrt{6}} = \frac{\sqrt{5}}{2\sqrt{3}} = \frac{1}{1{\cdot}549}.$$

Newton's Laws of Motion.—The three fundamental laws of Dynamics, called *Laws of Motion*, were first clearly set forth by Newton, and may be stated as follows:—

LAW I. (*Law of Inertia*).—**Every body continues in a state of rest, or of uniform motion in a straight line, except in so far as it may be compelled to change that state by external force acting on it.**

LAW II. (*Law of Force and Motion*).—**Rate of change of momentum is proportional to the force which causes it, and takes place in the direction of the force.**

LAW III. (*Law of Stress*).—**When two bodies mutually act upon each other, the momenta developed in the same time are equal but opposite in direction.**

Or, To every action there is an equal and opposite reaction.

Law I.—This Law asserts that matter is *indifferent* to motion, *i.e.*, has no *innate* tendency to start into motion when at rest, nor to change its motion, either in magnitude or in direction, when once it is made to move. Hence, a body at rest or in motion, and unacted upon by force, will continue to remain at rest, or to move on in a straight line with uniform motion. Should any change take place in its motion, then we immediately infer that the body has been acted upon by some external force. This tendency of matter to resist change in its state of rest or of uniform motion in a straight line is called **Inertia**, and the first Law is often spoken of as the *Law of Inertia*.

Law II.—The first Law asserts that change of momentum is caused by the action of force, and the second Law gives us a means of measuring this force, viz., that the force is proportional to the *rate of change of momentum*.

Let F = Force producing change of momentum.
" m = Mass of body.
" v_1, v_2 = Initial and final velocities of body.
" t = Time during which F acts.

Then, *Change of momentum* $= m(v_2 - v_1)$.

And, $\left.\begin{array}{c}\textit{Rate of change of}\\ \textit{momentum}\end{array}\right\} = \dfrac{m(v_2 - v_1)}{t}$.

∴ By the *Second Law of Motion*, we get :—

$$F \propto \frac{m(v_2 - v_1)}{t}.$$

Or,

$$F = \frac{m(v_2 - v_1)}{t} \times \text{constant}.$$

It now remains to establish the exact relation between those quantities. If we accept the definition of *Unit Force* given on page 2, Lecture I., Vol. I., as being *that force which, acting for unit time on unit mass, produces unit change of velocity*, we find the numerical value of the *constant* in the above equation to be *unity*.

i.e.,

$$F = \frac{m(v_2 - v_1)}{t}.$$

But we have shown in Lecture XX. that :—

$$a = \frac{v_2 - v_1}{t},$$

where a denotes the acceleration produced when the motion is uniformly accelerated.

$$\therefore \qquad F = m\,a.$$

The above definition is that of the *Absolute Unit* of Force; and, therefore, the force, F, as given by these equations, is expressed in absolute units. Engineers, however, prefer measuring their forces by the weights which they are capable of supporting, and the above equations may be modified to suit these units. Let P, P_1, be the statical measures of the forces required to produce accelerations, a, a_1, on a given mass, m; then by Law II., we get :—

$$P : P_1 = a : a_1.$$

If one of these forces be that due to gravity, viz., the weight, w, of a body, then the aceleration is g, and we get :—

$$P : w = a : g.$$

Or,

$$P = \frac{w\,a}{g} \quad . \quad . \quad . \quad . \quad . \quad . \quad . \quad . \quad . \quad \text{(I)}$$

This equation expresses the force, P, in the same units as w, and if w be stated in *pounds weight* that will be in what we have previously called *gravitation* units.

Law III.—This Law asserts that when two bodies mutually act upon each other, the momenta generated in each are equal, but in opposite directions. Thus, when a shot is fired from a gun, the force of the explosion produces momentum in the gun equal in amount to that of the shot, and causes the recoil. We shall, however, see later on that the other effects produced in the gun and the shot are not numerically equal. In the case of mutual action between two bodies incapable of relative motion, the Law asserts that they act and react on each other with equal forces. Thus, a weight lies on a table, and presses on it with a certain force; then the table reacts on the weight with an equal and opposite force, so that every action is accompanied by an equal and opposite reaction.

The truth of this Law has been assumed throughout the whole of the preceding parts of this treatise—viz., that the effort exerted between two bodies is always equal to the resistance overcome. The two equal and opposite forces caused by the mutual action between two bodies are together spoken of as a **Stress**, and for this reason the above Law is sometimes called the *Law of Stress*. The subject of *internal stress* will be discussed in another part of this work.

We shall now apply the preceding results to some examples.

EXAMPLE II.—A 40-lb. shot is fired from a 5-ton gun with an initial velocity of 1,500 feet per second. Find the velocity of the gun's recoil, and the mean force of the explosion, supposing the gun to be 10 feet long.

ANSWER.—Let W, w = Weight of gun and shot respectively.

" V, v = Velocity " "

(1) By the *Third Law*:—

Momentum of gun = momentum of shot.

$$\therefore \quad W\,V = w\,v$$

i.e., $$5 \times 2240 \times V = 40 \times 1500,$$

$$\therefore \quad V = \frac{40 \times 1500}{5 \times 2240} = 5{\cdot}36 \text{ ft. per sec.}$$

(2) In order to find the mean effort exerted during the explosion of the powder, we must first determine the acceleration of the shot along the muzzle of the gun. Since the gun is 10 feet long, and the velocity of the shot as it leaves the

gun is 1,500 ft. per second, we get, from the formula (VI_a), Lecture XX. :—

$$v^2 = 2\,a\,s,$$

$$\therefore \quad 1500^2 = 2 \times a \times 10,$$

$$\therefore \quad a = \frac{1500^2}{20} = 112{,}500 \text{ ft. per second per second.}$$

$$\text{But,} \quad P = \frac{w}{g} \times a,$$

$$\therefore \quad P = \frac{40}{32} \times 112{,}500 = 140{,}625 \text{ lbs.}$$

EXAMPLE III.—A railway train, exclusive of engine, weighs 200 tons, and moves on a level line. In 10 minutes its speed is increased from 10 miles per hour to 40 miles per hour. Determine the mean pull between the engine and train, the frictional resistances being taken at 10 lbs. per ton.

ANSWER.—The pull between the engine and train consists of two parts; (1) the force required to accelerate the train, and (2) the force required to overcome the frictional resistances.

(1) Let P_1 = Force required to accelerate the train,

$$\text{Then,} \quad P_1 = \frac{w\,a}{g} = \frac{w\,(v_2 - v_1)}{g\,t}.$$

$$\text{But,} \quad v_1 = 10 \text{ miles per hour} = \frac{44}{3} \text{ ft. per second.}$$

$$v_2 = 40 \quad \text{"} \quad = \frac{176}{3} \quad \text{"}$$

$$\text{And,} \quad t = 10 \text{ minutes} = 600 \text{ seconds.}$$

$$\therefore \quad P_1 = \frac{200 \times 2240 \times \left(\frac{176}{3} - \frac{44}{3}\right)}{32 \times 600} = 1026{\cdot}6 \text{ lbs.}$$

(2) The resistance of friction being 10 lbs. per ton,

The *total frictional resistance* = $P_2 = 200 \times 10 = 2000$ lbs.

$$\therefore \quad \left.\begin{array}{l}\text{Mean pull between}\\ \text{engine and train}\end{array}\right\} = P_1 + P_2 = 1026{\cdot}\dot{6} + 2000 = 3026{\cdot}\dot{6} \text{ lbs.}$$

Motion on a Double Inclined Plane.—Let A B C, D B C, be the two planes placed back to back, and let W_1, be the ascending, and W_2, the descending load, these loads being connected by a weightless rope passing over a frictionless and weightless pulley at B. We require to determine the motion—*i.e.*, the *acceleration* of the bodies, and the tension in the connecting rope.

Let α_1, α_2 = Inclinations of planes ABC, DBC respectively.

" μ_1, μ_2 = Coefficients of friction between W_1, W_2, and their respective planes.

" F_1, F_2 = Frictional resistances in the two cases.

" P_1, P_2 = Effective forces acting on W_1, W_2 respectively in causing motion.

" Q = Tension in connecting rope.

" a = Acceleration due to effective forces P_1, P_2.

Then, the effective force causing the *upward* motion of W_1, is:—

$$P_1 = Q - W_1 \sin \alpha_1 - F_1.$$

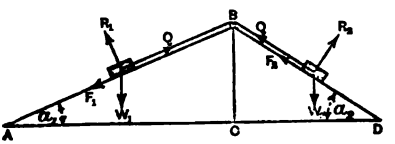

DOUBLE INCLINED PLANE.

Similarly, the effective force in causing the *downward* motion of W_2, is:—

$$P_2 = W_2 \sin \alpha_2 - Q - F_2.$$

But, $$F_1 = \mu_1 W_1 \cos \alpha_1.$$

And, $$F_2 = \mu_2 W_2 \cos \alpha_2.$$

$\therefore$ $$P_1 = Q - W_1 (\sin \alpha_1 + \mu_1 \cos \alpha_1), \quad . \quad . \quad . \quad . \quad (1)$$

And, $$P_2 = W_2 (\sin \alpha_2 - \mu_2 \cos \alpha_2) - Q. \quad . \quad . \quad . \quad . \quad (2)$$

Again, $$P_1 = \frac{W_1}{g} a \quad . \quad . \quad . \quad . \quad . \quad . \quad . \quad . \quad . \quad . \quad . \quad (3)$$

And, $$P_2 = \frac{W_2}{g} a. \quad . \quad . \quad . \quad . \quad . \quad . \quad . \quad . \quad . \quad . \quad . \quad (4)$$

To determine the acceleration, a :—

From, (1) + (2),

$$P_1 + P_2 = W_2(\sin\alpha_2 - \mu_2\cos\alpha_2) - W_1(\sin\alpha_1 + \mu_1\cos\alpha_1)$$

From, (3) + (4),

$$P_1 + P_2 = \frac{W_1 + W_2}{g} \times a.$$

$$\frac{W_1 + W_2}{g} \times a = W_2(\sin\alpha_2 - \mu_2\cos\alpha_2) - W_1(\sin\alpha_1 + \mu_1\cos\alpha_1),$$

$$\therefore \qquad a = \frac{W_2(\sin\alpha_2 - \mu_2\cos\alpha_2) - W_1(\sin\alpha_1 + \mu_1\cos\alpha_1)}{W_1 + W_2} \times g. \quad \text{(II)}$$

To determine the tension in the rope :—

Equation (1) ÷ (2), $\qquad \dfrac{P_1}{P_2} = \dfrac{Q - W_1(\sin\alpha_1 + \mu_1\cos\alpha_1)}{W_2(\sin\alpha_2 - \mu_2\cos\alpha_2) - Q},$

" (3) ÷ (4), $\qquad \dfrac{P_1}{P_2} = \dfrac{W_1}{W_2}.$

$$\therefore \qquad \frac{Q - W_1(\sin\alpha_1 + \mu_1\cos\alpha_1)}{W_2(\sin\alpha_2 - \mu_2\cos\alpha_2) - Q} = \frac{W_1}{W_2},$$

$$\therefore (W_1 + W_2)Q = W_1 W_2(\sin\alpha_1 + \mu_1\cos\alpha_1 + \sin\alpha_2 - \mu_2\cos\alpha_2)$$

$$\therefore \qquad Q = \frac{W_1 W_2(\sin\alpha_1 + \sin\alpha_2 + \mu_1\cos\alpha_1 - \mu_2\cos\alpha_2)}{W_1 + W_2} \quad \text{(III)}$$

We shall show how these formulæ are modified to suit some particular cases, but the student should try to prove each particular case independently of the general case just demonstrated.

CASE I.—Suppose the planes to be equally inclined to the horizon, and equally rough, so that $\alpha_1 = \alpha_2 = \alpha$, and $\mu_1 = \mu_2 = \mu$; then, from equation (II) :—

$$a = \frac{W_2(\sin\alpha - \mu\cos\alpha) - W_1(\sin\alpha + \mu\cos\alpha)}{W_1 + W_2} g,$$

$$\therefore \quad a = \frac{(W_2 - W_1)\sin\alpha - \mu(W_2 + W_1)\cos\alpha}{W_1 + W_2} g \quad . \quad . \quad \text{(II}_a\text{)}$$

From equation (III),

$$Q = \frac{2 W_1 W_2 \sin\alpha}{W_1 + W_2} \quad . \quad . \quad . \quad . \quad . \quad . \quad . \quad . \quad . \quad . \quad . \quad \text{(III}_a\text{)}$$

CASE II.—Let the planes be equally inclined, and smooth; so that $\alpha_1 = \alpha_2 = \alpha$, and $\mu_1 = \mu_2 = 0$; then, from equation (II):—

$$a = \frac{W_2 \sin \alpha - W_1 \sin \alpha}{W_1 + W_2} g,$$

$$\therefore \quad a = \frac{(W_2 - W_1) \sin \alpha}{W_1 + W_2} g \quad . \quad . \quad . \quad . \quad . \quad (II_b)$$

And from equation (III),

$$Q = \frac{2 W_1 W_2 \sin \alpha}{W_1 + W_2} \quad . \quad . \quad . \quad . \quad . \quad . \quad . \quad (III_b)$$

Equations (III_a) and (III_b) show that the degree of roughness of the planes does not affect the tension in the rope, when the planes are equally inclined to the horizon.

CASE III.—Let the plane, AB, be horizontal, and $\mu_1 = \mu_2 = \mu$, and suppose W_2 by falling vertically to drag W_1 along AB. In this case $\alpha_1 = 0$, and $\alpha_2 = 90°$; then, from equation (II):—

$$a = \frac{W_2 (\sin 90° - \mu \cos 90°) - W_1 (\sin 0 + \mu \cos 0)}{W_1 + W_2} g,$$

$$\therefore \quad a = \frac{W_2 - \mu W_1}{W_1 + W_2} g \quad . \quad . \quad . \quad . \quad . \quad . \quad . \quad . \quad . \quad . \quad . \quad (II_c)$$

And from equation (III),

$$Q = \frac{W_1 W_2 (1 + \mu)}{W_1 + W_2} \quad . \quad . \quad . \quad . \quad . \quad . \quad . \quad . \quad . \quad . \quad . \quad (III_c)$$

CASE IV.—In the previous case, let the horizontal plane be smooth, so that, $\mu = 0$:—

Then, $$a = \frac{W_2}{W_1 + W_2} g \quad . \quad . \quad . \quad . \quad . \quad . \quad . \quad (II_d)$$

And, $$Q = \frac{W_1 W_2}{W_1 + W_2} \quad . \quad . \quad . \quad . \quad . \quad . \quad . \quad (III_d)$$

CASE V.—Suppose the weights to be suspended over the frictionless and weightless pulley B, and the parts of the rope to hang vertically.

In this case, $\alpha_1 = \alpha_2 90°$; $\mu_1 = \mu_2 = 0$; then:—

From equation (II),

$$a = \frac{W_2 - W_1}{W_1 + W_2} g \quad . \quad . \quad . \quad . \quad . \quad . \quad . \quad (II_e)$$

From equation (III),

$$Q = \frac{2\,W_1\,W_2}{W_1 + W_2} \quad . \quad . \quad . \quad . \quad . \quad . \quad . \quad (III_e)$$

These last equations are of great importance to the student of *Theoretical Mechanics*, because they enable him, by means of an Atwood's machine, to determine the value of g, at the place where the experiment is conducted.

EXAMPLE IV.—A cage weighing 1 ton is being raised from a mine with an acceleration of 10 feet per second. Find the tension in the rope. If a miner, whose weight is 150 lbs., is raised with the cage, find the pressure between him and the cage. Again, if the cage be lowered with the same acceleration, what would then be the tension in the rope, and the pressure between the man and cage?

ANSWER.—(1) *To find tension in rope during ascent of cage.*

Let W = Weight of cage = 1 ton = 2,240 lbs.
" w = Weight of man = 150 lbs.
" Q = Tension of rope in lbs.
" a = Acceleration of cage = 10 ft. per sec. per sec.

Then, neglecting the weight of the rope, and in the meantime that of the man, we get:—

Effective pull causing motion = P = Q − W.

But, by the *Second Law of Motion*, $P = \frac{W}{g}a$.

$$\therefore \qquad Q - W = \frac{W}{g}a.$$

Hence,

$$Q = W\left(1 + \frac{a}{g}\right)$$

$$\therefore \qquad Q = 2240 \times \left(1 + \frac{10}{32}\right) = 2{,}940 \text{ lbs.}$$

That is, the tension in the rope is *greater* than the weight raised by 700 lbs.

If the weight of the miner be taken into account, we must increase W, by 150, and then we get:—

$$Q = 3136{\cdot}9 \text{ lbs.}$$

(2) *To find the pressure between man and cage.*

$$\left.\begin{array}{l}\textit{Pressure between man}\\ \textit{and cage}\end{array}\right\} = \left\{\begin{array}{l}\textit{Weight of man + Force required}\\ \textit{to accelerate his upward motion}\end{array}\right.$$

$$\text{,,} \qquad \text{,,} \qquad = w + \frac{w}{g}a,$$

$$\therefore \qquad w_1 = 150 + \frac{150}{32} \times 10 = 196{\cdot}9 \text{ lbs.}$$

Under these circumstances he will feel heavier by 46·9 lbs.

(3) *To find tension in rope during descent of cage.*

In this case, we get:—

$$\left.\begin{array}{l}\textit{Effective pull causing}\\ \textit{motion}\end{array}\right\} = P = W - Q,$$

And,

$$P = \frac{W}{g} \times a,$$

$$\therefore \qquad W - Q = \frac{W}{g} \times a,$$

$$\therefore \qquad Q = W\left(1 - \frac{a}{g}\right)$$

$$Q = 2{,}240 \times \left(1 - \frac{10}{32}\right) = 1{,}540 \text{ lbs.}$$

That is, the tension in the rope is *less* than the weight of the cage by 700 lbs.

Similarly, it can be shown that the pressure between the man and the floor of the cage during descent, is 103·1 lbs.; or, 46·9 lbs. less than his real weight.

EXAMPLE V.—In a double inclined plane, having a rise of 1 in 20, the loaded and empty trucks run on parallel lines of rails, the connection being made by means of two ropes passing round drums at the summit of the plane. Five loaded trucks

when descending pull up an equal number of empty ones. Each empty truck weighs 5 cwts., and when loaded carries 20 cwts. of material. The diameter of the drums at the top of the incline is 8 feet, and on the same shaft is fitted a brake pulley 6 feet in diameter. The length of the inclined plane is 1 mile. Taking the coefficient of friction between the trucks and the rails at 20 lbs. per ton, but neglecting other frictional resistances; determine (1) the acceleration of the trucks and their speed at the end of one minute after starting; (2) the tension in the ropes during the free motion of the whole; and (3) the constant frictional resistance which must be exerted at the rim of the brake pulley, during the last three-eighths of the run, in order to just bring the whole to rest at the end of the journey.

ANSWER.—Using the same letters as in the text.

Let W_1 = Total weight of five empty trucks = 25 cwts.
" W_2 = " " loaded " = 125 "
" P_1 = Effective force causing motion of W_1.
" P_2 = " " " W_2.
" Q = Tension in ropes.
" α = Inclination of the plane.
" μ = Coefficient of friction = 20 lbs. per ton = $\frac{1}{112}$.

Then, $\sin\alpha = \frac{1}{20}$; and since α is small we may assume $\cos\alpha = 1$.

(1) *To find the acceleration of the trucks.*

The effective pull causing the motion of the empty trucks, is:—

$$P_1 = Q - W_1(\sin\alpha + \mu\cos\alpha),$$

$$\therefore\ P_1 = Q - 25\left(\frac{1}{20} + \frac{1}{112} \times 1\right) = Q - \frac{165}{112}\text{ cwt.} \quad . \quad . \quad (1)$$

The effective pull causing the motion of the loaded trucks, is:—

$$P_2 = W_2(\sin\alpha - \mu\cos\alpha) - Q,$$

$$\text{"} = 125\left(\frac{1}{20} - \frac{1}{112} \times 1\right) - Q = \frac{575}{112} - Q\text{ cwt.} \quad . \quad . \quad (2)$$

Again, by *Second Law of Motion*, we get :—

$$P_1 = \frac{W_1}{g} \times a = \frac{25}{32} \times a \text{ cwt.} \quad . \quad . \quad . \quad . \quad (3)$$

$$P_2 = \frac{W_2}{g} \times a = \frac{125}{32} \times a \text{ cwt.} \quad . \quad . \quad . \quad (4)$$

(1) + (2), $P_1 + P_2 = \frac{575}{112} - \frac{165}{112} = \frac{205}{56}$ cwt.

(3) + (4), $P_1 + P_2 = \left(\frac{25}{32} + \frac{125}{32}\right) \times a = \frac{150}{32} a$ cwt.

$\therefore \quad \frac{150}{32} \times a = \frac{205}{56}$

$\therefore \quad a = 0{\cdot}78$ ft. per sec. per sec.

That is, the trucks move with an acceleration of 0·78 foot per second per second.

At the end of one minute from starting the speed would be :—

$$v = a\,t = {\cdot}78 \times 60 = 46{\cdot}8 \text{ ft. per sec.}$$

Or, at the end of one minute they would be moving with a speed somewhat greater than 30 miles per hour.

(2) *To find tension in the ropes.*

Since we have assumed that the machinery at the top of the incline offers no resistance to the motion, it is evident that the tension in each rope will be the same. Hence :—

(1) ÷ (2), $\frac{P_1}{P_2} = \frac{Q - \frac{165}{112}}{\frac{575}{112} - Q} = \frac{112\,Q - 165}{575 - 112\,Q}$.

(3) ÷ (4), $\frac{P_1}{P_2} = \frac{W_1}{W_2} = \frac{25}{125} = \frac{1}{5}$.

$\therefore \quad \frac{1}{5} = \frac{112\,Q - 165}{575 - 112\,Q}$.

$\therefore \quad Q = \frac{1400}{672} = 2{\cdot}08$ cwt.

(3) *To find the frictional resistance at the rim of the brake pulley in order to bring the trucks to rest at the end of the run.*

Here we have first to obtain the speed of the trucks at the instant when the brake is applied, and then find the retardation or negative acceleration necessary to bring the trucks to rest at the desired place.

The velocity v, of the trucks at the instant when the brake is applied is given by the formula :—

$$v^2 - v_1^2 = 2\,a\,s.$$

Where v_1 = Initial velocity = 0 in this case.
" a = Acceleration just found = 0·78 ft. per sec. per sec.
" s = Distance traversed = $\frac{5}{8}$ mile.

The acceleration during the application of the brake may be found by the same formula. In this case, however, the initial velocity is v, and the final velocity is zero.

Let a_1 = Acceleration of the trucks during the application of the brake.
" s_1 = Distance traversed = $\frac{3}{8}$ mile.

Then, before the brakes are applied :—

$$v^2 - 0^2 = 2\,a\,s$$

Or, $$v^2 = 2\,a\,s.$$

And after the brakes have been applied :—

$$0^2 - v^2 = 2\,a_1\,s_1,$$

Or, $$v_2 = -2\,a_1\,s_1.$$

$$\therefore \quad a_1 = -\frac{a\,s}{s_1} = -\frac{\cdot 78 \times \frac{5}{8}}{\frac{3}{8}} = -1\cdot 3 \text{ ft. per sec. per sec.}$$

(4) *To determine the tensions in the two ropes.*

These will not now be equal as when the motion was free. The tension in the rope coming on to the drum will be much less than before, whilst that on the other rope will be greater.

Let Q_1, Q_2 = Tensions in the ropes attached to the empty and loaded trucks respectively.

Then the effective pull P_1, causing the motion of the ascending trucks is as before :—

$$P_1 = Q_1 - W_1(\sin\alpha + \mu\cos\alpha)$$

But, $$P_1 = \frac{W_1 a_1}{g}$$

$$\therefore \quad Q_1 = W_1\left\{\sin\alpha + \mu\cos\alpha + \frac{a_1}{g}\right\}$$

$$\text{,,} \quad = 25\left\{\frac{1}{20} + \frac{1}{112} \times 1 - \frac{1\cdot3}{32}\right\}\text{cwt.,}$$

$$\text{,,} \quad = \frac{25 \times 20\cdot5}{1120}\text{ cwt.} = 51\cdot25\text{ lbs.}$$

Similarly, the tension Q_2, in the rope attached to the loaded trucks is,

$$Q_2 = W_2\left\{\sin\alpha - \mu\cos\alpha - \frac{a_1}{g}\right\}$$

$$\text{,,} \quad = 125\left\{\frac{1}{20} - \frac{1}{112} \times 1 + \frac{1\cdot3}{32}\right\}\text{cwt.}$$

$$\text{,,} \quad = \frac{125 \times 91\cdot5}{1120}\text{ cwt.} = 1143\cdot75\text{ lbs.}$$

The difference in the tensions in the two ropes is caused by the resistance offered by the brake. Hence, the resultant couple due to this difference in the tension must be balanced by the couple at the brake wheel.

Let F = Frictional resistance at the rim of the brake wheel.
,, R = Radius of the drums = 4 ft.
,, r = Radius of brake wheel = 3 ft.

Then, $$F \times r = (Q_2 - Q_1) \times R,$$

$$\therefore \quad F \times 3 = (1143\cdot75 - 51\cdot25) \times 4,$$

$$\therefore \quad F = 1456\cdot7\text{ lbs.}$$

Energy.—If we raise a body of W lbs. weight through a vertical height of h feet from some given datum level, we confer upon that body the capability of doing work equal to $W\,h$ ft.-lbs. For, in raising the body we expend $W\,h$ ft.-lbs. of work, and if it be allowed to return to its original level it will give out an equal amount of work.

Again, we have seen that if a body be in motion and its speed reduced, some force must have acted upon it in bringing about this change of state. Further, this resisting force must have been overcome through some distance, and, therefore, work is expended. Thus, a body in motion is capable of doing work, the measure of which is the work done against a resisting force or forces in bringing the body to rest.

This capability of doing work which a body possesses in virtue of its position or condition is called **Energy**. Hence, we have the following :—

DEFINITION.—**The energy of a body is its capability of doing work in virtue of its Position, Condition, or Motion.**

It is usual to distinguish between that form of energy due to the position or state of a body, and that due to its motion. To the former the term **Potential** is applied, and to the latter **Kinetic**. This distinction may be stated in the form of a definition.

DEFINITIONS.—**Potential Energy is that form of energy which a body possesses in virtue of its Position or Condition.**

Kinetic Energy is that form of energy which a body possesses in virtue of its Motion.

Thus, a raised weight, such as the weight of a clock, or the monkey of a pile-driving engine, has *potential* energy in virtue of its *position*. In the first case the slowly falling weight gives up its stored energy to the mechanism of the clock in overcoming frictional resistances, and thus keeps the clock going, the pendulum being simply a regulator or governor. In the second case, the monkey is allowed to fall freely and its energy is employed in forcing the pile into the ground at the instant of the blow. Similarly, the water in a mill dam possesses potential energy due to its *position* relatively to the water wheel. Again, a stretched helical spring, or coiled spiral spring such as is used in watches and clocks, possesses potential energy due to its *stretched condition*. A lump of coal, or gunpowder, has potential energy in virtue of its *chemical condition;* a magnet has potential energy in virtue of its *magnetic condition;* and the steam in a boiler has potential energy in virtue of its *heat condition*, and so on.

When the monkey of the pile driver is at the top of its stroke its energy is entirely in the potential form. When it is descending it is evident that its potential energy is rapidly decreasing whilst its kinetic energy is increasing.

Neglecting frictional and other resistances, the **Principle of the Conservation of Energy** (see Lecture IV., Vol. I.) asserts that—

The Loss of Potential Energy = The Gain of Kinetic Energy.

Consequently, at the instant when the monkey strikes the head of the pile, the energy of the monkey is wholly Kinetic. The work done in driving the pile into the ground is immediately derived from the kinetic energy of the falling weight, but the whole of this energy is not thus employed, for the faces of the pile and monkey have been heated by the blow. This shows that part of the energy stored in the falling weight has been transformed into heat energy. Further, at the instant of striking, a loud noise is heard, which shows that there is also a transformation into sound energy. Thus, energy appears under many different forms, such as mechanical, electrical, chemical, heat, light, sound, &c., and can, by suitable arrangements, be changed from one kind into any of the others. In nature all is change or transformation, but there is no annihilation; so what appears as a loss to the engineer simply means change into some other form which he does not desire, but which he has no power to entirely prevent.

Expression for Kinetic Energy.—We have already seen, that the expression for mechanical potential energy is:—

$$\text{Potential Energy} = E_P = W\,h$$

Where, W = Weight of body,

And, h = Height of body above zero level.

It now remains to determine the expression for kinetic energy.

First, take the case of the raised weight whose potential energy in its highest position is $W\,h$, and suppose it to fall freely. Its kinetic energy at the instant when it strikes the ground is:—

$$E_K = W\,h.$$

But, if v = velocity at that instant, we have:—

$$v^2 = 2\,g\,h,$$

Or,

$$h = \frac{v^2}{2\,g}.$$

$$\therefore \qquad E_K = \frac{W\,v^2}{2\,g} \quad . \quad . \quad . \quad . \quad . \quad . \quad \text{(IV)}$$

Thus, if the monkey of the pile driver weigh 10 cwts., and reaches the pile with a velocity of 40 feet per second, it has kinetic energy :—

$$E_K = \frac{10 \times 112 \times 40^2}{2 \times 32} = 28{,}000 \text{ ft.-lbs.}$$

If the pile be driven 3 inches into the ground at each blow, what is the *mean* resistance offered to its motion, supposing there are no losses from heating, &c.?

Let R_m = Mean resistance of ground in lbs.
,, s = Distance *in feet* through which the pile is driven.

Then, *Work done in driving the pile* } = { *Work given out by monkey.*

But, *Work given out by monkey* } = { *Kinetic energy at instant of striking the pile + Work done in falling through 3″.*

$$\therefore \qquad R_m \times s = \frac{W v^2}{2g} + W \times s,$$

$$i.e., \qquad R_m \times \frac{3}{12} = 28{,}000 + 10 \times 112 \times \frac{3}{12},$$

$$\therefore \qquad R_m = 113{,}120 \text{ lbs.} = 50{\cdot}5 \text{ tons.}$$

Energy Equations.—The expression for the kinetic energy given in equation (IV) is perfectly general, and therefore independent of the manner in which the velocity, v, is acquired. That is to say, if a body of weight, W, be moving with a velocity, v, in any direction whatever, its kinetic energy is still given by the equation :—

$$E_K = \frac{W v^2}{2g}.$$

For, manifestly, the direction of motion cannot in any way affect its energy state, other things being equal. Nevertheless, we can deduce the expression from more general considerations as follows :—

Let a body of weight, W, have its velocity changed in magnitude from v_1 to v_2 by a constant force P, acting through a distance s. Then—

Change of body's kinetic energy } = { *Work done by or against the force*

And, *Work done by or on* $P = P \times s$.

But, by eqation (I), $$P = \frac{W a}{g},$$

And, by equation (VI), Lecture XX.,

$$s = \frac{v_2^2 - v_1^2}{2a},$$

$$\therefore \qquad P \times s = \frac{W(v_2^2 - v_1^2)}{2g} = \text{change of } E_K. \quad (V)$$

If the body start from rest, and have a final velocity, v, we get:—

$$\text{Change of } E_K = \frac{W v^2}{2g} = \text{Total } E_K \text{ in body},$$

which is just the same result as that given by equation (IV).

Next, take the case of a body moving with uniform velocity, v, against some constant resistance, F, which resistance may be frictional or otherwise. To maintain this constant speed a force equal to F must act on the body in opposition to the resistance; but no part of this force is employed in changing the kinetic energy of the body, since, by supposition, no change occurs in its velocity. The kinetic energy of the body is constantly $= \frac{W v^2}{2g}$, and the *Work done against resistances* $= F s$.

If, now, some other force, P, acts on the body in the direction of motion, the velocity will change, and, therefore, the energy of the body will also change.

Let Q = Resultant force acting on body $= P \sim F$.
" v_1, v_2 = Velocities of body before and after action of P.
" s = Distance through which body moves under P.

Then, $$Q \times s = F \times s + \frac{W(v_2^2 - v_1^2)}{2g} \quad . \quad . \quad . \quad (VI)$$

This is a very general equation of energy, and is sometimes stated thus:—

Energy exerted = Work done + Change in Kinetic Energy.

EXAMPLE VI.—The height and length of an inclined plane are 20 feet and 100 feet respectively: a body weighing 100 lbs. is placed at the top of the plane and allowed to slide along its whole length; the coefficient of friction between the plane and

the body is 0·15; how many units of work (foot-pounds) are accumulated in the body, and what is its velocity when it reaches the foot of the plane? (You may assume the pressure on the plane equal to the weight of the body). (S. & A. Adv. Exam.)

ANSWER.—Let F = Resultant force urging body down the plane.

Then, $F = W \sin \alpha - \mu R = W \sin \alpha - \mu W$, very approximately,

$$,, \quad = 100\left(\frac{20}{100} - 0{\cdot}15\right) = 5 \text{ lbs.}$$

When body reaches the foot of the plane, we have:—

$$E_K = F \times l = 5 \times 100 = 500 \text{ ft.-lbs.}$$

Let v = Velocity at foot of plane.

Then, $$\frac{W v^2}{2g} = E_K.$$

i.e., $$\frac{100 \times v^2}{2 \times 32} = 500,$$

$\therefore$ $$v = 17{\cdot}9 \text{ ft. per sec.}$$

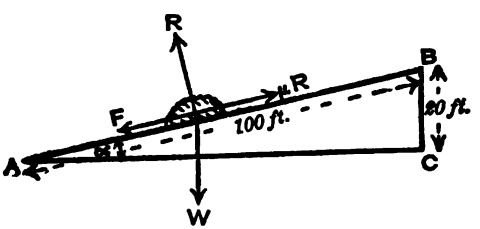

DIAGRAM ILLUSTRATING EXAMPLE VI.

The kinetic energy at the foot of the plane could be obtained immediately from equation (VI), thus:—

$$\textit{Energy exerted} = W \sin \alpha \times l = 100 \times \frac{20}{100} \times 100 = 2000 \text{ ft.-lbs.}$$

$$\textit{Work done} = \mu W l = 0{\cdot}15 \times 100 \times 100 = 1500 \text{ ft.-lbs.}$$

$$\textit{Change in } E_K = \textit{Energy at foot of plane} = \frac{W v^2}{2g}.$$

$\therefore$ **Energy exerted = Work done + Change in E_K.**

$$\therefore \qquad 2000 = 1500 + \frac{W v^2}{2g}.$$

$$\therefore \quad \left.\begin{array}{l}\text{E}_\text{K} \text{ at foot of} \\ \text{plane}\end{array}\right\} = \frac{W v^2}{2g} = 500 \text{ ft.-lbs.}$$

$$\therefore \text{ also,} \qquad v = \sqrt{\frac{500 \times 2 \times 32}{100}} = 17{\cdot}9 \text{ ft. per sec.}$$

EXAMPLE VII.—Show by a diagram the amount of work done in *slowly compressing* a spiral spring through 6 inches, supposing the spring to shorten 1 inch for every 100 lbs. pressure. If a weight of 100 lbs. *falls* from a height of 4 feet on the top of the spring, how much will it be compressed? (S. & A. Adv. Exam., 1892.)

ANSWER.—As explained in Lecture II., Vol. I., the diagram of work done in slowly compressing a spiral spring, is a right angled triangle whose base represents the compression produced, and its perpendicular side the force required to produce that compression.

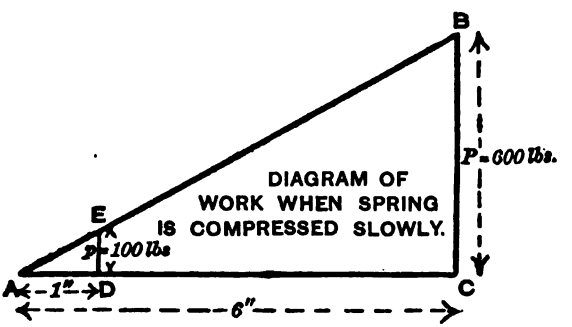

DIAGRAM ILLUSTRATING EXAMPLE VII.

Let A B C represent the diagram of work done in slowly compressing the spring.

Where, A C = Compression produced = 6″.

And, C B = Force required = P.

Let, D E = Force required to compress spring 1″, = p = 100 lbs.

Then, $P : p = CB : DE = AC : AD.$

That is, $P : 100 = 6'' : 1''.$

$\therefore \quad P = 600$ lbs.

$\therefore$ Work done $= \frac{1}{2} P \times L = \frac{1}{2} \times 600 \times 6'' = 1800$ in.-lbs.

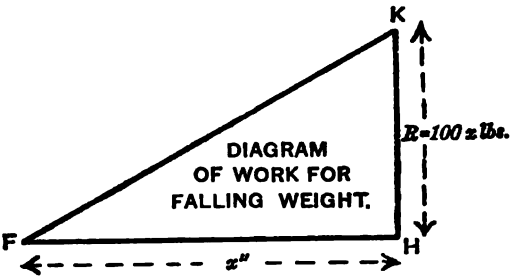

DIAGRAM ILLUSTRATING EXAMPLE VII.

Next, suppose the spring to be compressed by a weight which falls from a height of 4 feet.

Let x = Number of *inches* by which spring is compressed by falling weight.

Then, $48 + x$ = Number of inches through which weight actually falls.

Since a force of 100 lbs. is required to compress the spring 1 inch, a force $R = 100\,x$ lbs. will be required to compress it x inches.

But,

$$\left.\begin{matrix}\textit{Work done in compress-}\\ \textit{ing spring}\end{matrix}\right\} = \left\{\begin{matrix}\textit{Work done by falling}\\ \textit{weight.}\end{matrix}\right.$$

$$\therefore \quad \tfrac{1}{2} R \times x = W(48 + x).$$

$$\therefore \quad \tfrac{1}{2} \times 100\,x \times x = 100(48 + x).$$

That is, $x^2 = 2x + 96.$

Or, $x = 10{\cdot}85$ inches.

EXAMPLE VIII.—A blowing-fan 30 inches in diameter revolves at a speed of 1,000 revolutions per minute, and propels the wind with a velocity equal to $\frac{7}{8}$ of the velocity of the tips of the vanes; the wind is driven through a pipe having a sectional area

of 200 square inches. Neglecting the power that is required to overcome friction, will you show the amount of power which is required to force the above quantity of air? Work it out in arithmetic, either by the law of falling bodies or in any better way that may suggest itself to you. (S. & A. Hons. Exam.)

ANSWER.—This is simply a question on work and energy.

Let W = Weight of air expelled from fan *per second.*
" A = Sectional area of delivery pipe of fan = 200 sq. ins.
" v = Velocity of air as it leaves tips of vanes.

Then, $v = \frac{7}{8} \times$ *Velocity of tips of vanes*

$$" = \frac{7}{8} \times \pi d n$$

$$" = \frac{7}{8} \times \frac{22}{7} \times \frac{30}{12} \times \frac{1000}{60} = 114{\cdot}6 \text{ ft. per sec.}$$

$$\left.\begin{array}{l}\textit{Volume of air expelled}\\ \textit{per second}\end{array}\right\} = A\,v$$

$$" \qquad " \qquad = \frac{200}{144} \times 114{\cdot}6 = 159{\cdot}16 \text{ cub. ft. per sec.}$$

By calculation from the density of air, it can be shown that *13 cubic feet of air at atmospheric pressure weigh 1 lb. very nearly,* and assuming this, we get :—

$$\textit{Weight of } 159{\cdot}16 \textit{ cub. ft.} = W = \frac{159{\cdot}16}{13} = 12{\cdot}24 \text{ lbs. nearly.}$$

$$\text{Hence, } \textit{Work done per sec.} = \textit{Energy exerted} = \frac{W\,v^2}{2\,g}$$

$$" \qquad " \qquad = \frac{12{\cdot}24 \times 114{\cdot}6^2}{2 \times 32} \text{ ft.-lbs. per sec.}$$

$$" \qquad " \qquad = \frac{12{\cdot}24 \times 114{\cdot}6^2 \times 60}{2 \times 32} \text{ ft.-lbs. per min.}$$

$$\therefore \qquad \text{H.P. exerted} = \frac{12{\cdot}24 \times 114{\cdot}6^2 \times 60}{2 \times 32 \times 33{,}000} = 4{\cdot}57 \text{ nearly.}$$

LECTURE XXI.—QUESTIONS.

1. Define momentum, and state how it is measured. State and explain, by aid of examples, Newton's three laws of motion. A shot weighing half a ton is fired from a 100-ton gun with a velocity of 2,000 feet per second. Neglecting the weight of the powder, find the velocity of the gun's recoil. *Ans.* 10 feet per second.

2. A man weighing 140 lbs. descends in a lift with an acceleration equal to $\frac{1}{8}g$. What pressure does he exert on the floor of the lift? How would your answer differ if the lift were ascending instead of descending? *Ans.* 122·5 lbs.; 157·5 lbs.

3. A railway train, exclusive of engine, weighs 150 tons, and in starting along a level line from rest it attains a speed of 30 miles an hour in 5 minutes. What has been the mean pull between the engine and train, the resistance being taken at 10 lbs. per ton? (S. & A. Adv. Exam., 1887.) *Ans.* 3,040 lbs.

4. A locomotive and its train weigh 220 tons, and the frictional resistance at all speeds may be taken at 2,000 lbs. If the tractive force of the engine is constantly 3,500 lbs., find in what time from starting the train can attain a speed of 40 miles per hour (1) on a level line, and (2) going down an incline of 1 in 220. Find, also, the distance travelled in both cases in attaining the above speed. *Ans.* (1) 10 minutes 2 seconds, 3·34 miles; (2) 4 minutes 1 second, 1·34 miles.

5. In a steam engine, the piston, which is 40 inches diameter and weighs 2,000 lbs., comes off the rod just as it is commencing its inward stroke. The mean steam pressure is 50 lbs. per square inch. Find the velocity with which the piston will strike the cover at the opposite end of the cylinder, the stroke being 4 feet. *Ans.* 89·7 feet per second.

6. One end of a string is fixed; it then passes over a movable pulley to which a weight, W, is attached. The string then passes over a fixed pulley, and a smaller weight, w, is attached to its other end, all three sections of the string being vertical. Show that, neglecting the weights of the pulleys, the acceleration with which W descends is $\left(\frac{W - 2w}{W + 4w}\right)g$. Verify this result (1) when w is small compared with W, and (2) when W is small compared with w. (Wool. Roy. Milly. Acad. Exams.)

7. It is very evident that a railway train requires a considerable amount of force to set it in motion, but there is a popular notion existing that a less amount of power or force is required to bring the same train to a state of rest. Will you explain clearly the natural principles upon which the whole case depends, and compare the force necessary both for giving motion to the train and in producing the opposite condition? (S. & A. Hons. Exam.)

8. Distinguish between work and energy, and between potential and kinetic energy. Give examples of both forms of energy. State the principle of the conservation of energy, and show its connection with the axiom that "perpetual motion" is impossible. A simple pendulum is pulled aside till its heavy bob is raised h inches vertically, and then let go. Find its velocity when it passes its lowest point. *Ans.* $\sqrt{\frac{gh}{6}}$.

9. Prove the formula which gives the number of units of work stored up in a given weight when moving with a given velocity. A weight of 100 lbs. is moving with a velocity of 64 feet per second, how many foot-pounds of work have been expended in producing this result? (S. & A. Adv. Exam.) *Ans.* 6,400 foot-pounds.

10. A hammer head weighs 5 tons and reaches the anvil with a velocity of 10 feet per second; what amount of energy, measured in foot-pounds, is stored up in the hammer at the instant of the blow? *Ans.* 17,500 foot-pounds.

11. The head of a steam hammer weighs 10 cwts., and has a fall of 8 feet. If it indent the iron on which it falls by 1 inch, find the mean force exerted on the iron during compression. (S. & A. Adv. Exam., 1889.) *Ans.* 970 cwts.

12. Of two steam hammers, one weighs 5 tons and reaches the anvil with a velocity of 10 feet per second, and the other weighs 10 tons and reaches the anvil at a velocity of 5 feet per second; will you compare and distinctly characterise the conditions of the blow of each of the two hammers? (S. & A. Hons. Exam.)

13. Referring to a steam hammer, in which steam is admitted above the piston to assist gravitation, will you describe the combination of forces at work in producing the blow, and, as far as you may be able, the nature of the blow as depending on velocity and mass or weight of the hammer at the moment of impact? (S. & A. Hons. Exam.)

14. What do you understand by energy, and how is it measured? The head of a steam hammer weighs 50 cwts., steam is admitted on the under side for lifting only, and there is a drop of 5 feet. What will be the average compressive force exerted during a blow from this hammer, on the supposition that the duration of the blow—that is, the time during which the hammer is compressing the iron under operation—is $\frac{1}{10}$ second? (S. & A. Hons. Exam., 1887.) *Ans.* 2,236 cwts.

15. The monkey of a pile driver weighs 15 cwts., and the drop is 6 feet. The blow causes the pile to go down through 4 inches; what is the frictional resistance of the earth? (S. & A. Hons. Exam., 1881.) *Ans.* 285 cwts.

16. Compare the force expended in pile driving by a ram or monkey of 1 ton falling 20 feet, with that of a weight of 2 tons falling 10 feet. If one blow of the former moves the pile 9 inches, what is the average resistance that is opposed to its motion? (S. & A. Adv. Exam., 1896.) *Ans.* (1) 2 : 1, (2) 27·7 tons.

17. Two bodies, weighing 5 lbs. and 3 lbs. respectively, are connected by a perfectly flexible weightless string which passes over a smooth pulley. The heavier body draws up the lighter. When it has fallen through 5 feet, what is the kinetic energy of the bodies and the velocity? ($g = 32$.) (S. & A. Theor. Mechs. Elem. Exam., 1880.) Determine also the acceleration of the system, and the tension in the string. *Ans.* (1) 10 foot-pounds, (2) 8·94 feet per second; (3) 8 feet per second per second; (4) 3·75 lbs.

18. State Newton's third law of motion, and give his illustrations of it. Weights of 5 and 11 lbs. are connected by a weightless thread. The latter is placed on a smooth horizontal table, while the former hangs over the edge. If the bodies are then allowed to move under the action of gravity, what is the tension of the thread? (S. & A. Theor. Mechs. Adv. Exam., 1876.) Find, also, the acceleration produced, and the kinetic energy of the system at the end of 4 seconds. *Ans.* (1) 3·44 lbs., (2) 10 feet per second per second, (3) 400 foot-pounds.

19. A train of locomotive and carriages weighs 60 tons. If it be sup-

posed to run down an incline of 1 in 265 for 7½ miles, starting with zero velocity, unopposed by anything but its own inertia, and unaccelerated by anything but its own weight; what would be its velocity, its momentum, and its kinetic energy at the foot of the incline? (C. & G. Mech. Eng. Hons. Exam., 1884.) *Ans.* 97·84 feet per second, 5,870 foot-tons per second, 8,925 foot-tons.

20. What meaning do you attach to the phrase *horse-power?* A fire-engine pump is provided with a nozzle, the sectional area of which is 1 square inch, and the water is projected through the nozzle with a velocity of 130 feet per second; find the horse-power of the engine required to drive the pump, irrespective of the loss by resistance of the working parts. The weight of a cubic foot of water is 62½ lbs. (S. & A. Hons. Exam.) *Ans.* 27·1 H.P.

21. State Newton's second law of motion. Explain briefly how the measure of force is derived from this law. In the equation $P = mf$, in what units is P, when the units of mass, distance, and time are a pound, a foot, and a second? (S. & A. Adv. Theor. Mechs. Exam., 1896.)

22. A steam engine is employed to raise coals, and it is calculated that in order to set in motion the winding drums, flywheel, cages, ropes, &c., which are concerned in the motion, it has to do the work of imparting a linear velocity of 36 feet per second, to 60 tons of material in *half-a-minute* at each lift. What effective horse-power is consumed in overcoming the inertia of the aggregate weight of 60 tons, and in setting up the velocity, estimated as above stated, in the time assigned? (S. & A. Hons. Exam.) *Ans.* 165 H.P.

23. In lifting water into a tender by a scoop running along a trough while the train is going at rapid speed, the height of the lift is 7½ feet. What speed in miles per hour will just cause the water to be lifted through that height? (S. & A. Hons. Exam.) *Ans.* 15 miles per hour nearly.

24. A vertical pipe, carried by the tender of a locomotive engine, and terminating in a scoop with a flat mouth, picks up water from a trough laid on a railway. If the speed of the engine and tender be 22 miles per hour, find the height to which the water will rise in the pipe. Upon what theory do you proceed? (S. & A. Hons. Exam., 1882.) *Ans.* 16·3 feet.

25. A hammer head of 2½ lbs., moving with a velocity of 50 feet per second, is stopped in 0·001 second. What is the average force of the blow? What do you mean by this average? What is the difference between a time average and a space average? When are they the same? (S. & A. Adv. Exam., 1897.)

26. A body of 4 lbs. moving with a speed of 20 feet per second overtakes one of 200 lbs. moving at 2 feet per second in the same direction. When the collision events are finished (friction stilling the relative motions) and both bodies go on together, what is their common velocity? What mechanical energy has been lost? (S. & A. Hons. Exam., Part I., 1898.)

27. A body of 200 lbs. is acted on by a force F, which alters. No other force acts on the body. When the body has passed through the distance x feet, the force in pounds is as follows:—

x	0	·1	·2	·3	·4	·5	·6	·7	·8	·9	1·0
F	20	21	21	20	19	18·5	18·0	13·5	9	4·5	0

Using either a graphical or arithmetical method, find—

(*a*) The average force acting on the body through this total distance of 1 foot.

(*b*) The work done upon the body from $x = 0$ to $x = \cdot 4$.

(*c*) The answer to (*b*) being the kinetic energy added to the body; if the velocity was 0 when x is 0, what is the velocity when $x = \cdot 4$? (S. & A. Adv. Exam., 1898.)

28. A body and a frictionless carriage together weighing 20 lbs. are on a level table, and get a simple harmonic motion from my hand, moving 1 foot on each side of a mid position, one *complete* oscillation taking one second. Show on a diagram what is the force which my hand must exert in each position of the body, and state the direction of the force. You must state the amount of the force for some one position so that we may judge of the scale of your diagram. (S. & A. Hons. Exam., Part I., 1898.)

LECTURE XXII.

CONTENTS.—Energy of a Rotating Body—Moment of Inertia of a Body about an Axis—Definitions of Moment of Inertia and Radius of Gyration—Propositions I., II., and III.—Methods of Calculating Moments of Inertia—Examples I., II., and III.—Tables of Radii of Gyration of Solids and Sections—Equation of Energy for a Rotating Body—Examples IV., V., VI., and VII.—Determination of Energy of Flywheels—Centripetal and Centrifugal Forces—Definitions of Centripetal and Centrifugal Forces—Example VIII.—Straining Actions due to Centrifugal Forces—Example IX.—Questions.

Energy of a Rotating Body.—The deduction of the equation for energy of rotation is complicated by the fact that particles of the body at different distances from the axis of rotation possess different energies, due to their different linear velocities. To obtain the energy of the whole body, we must, therefore, take the sum of the energies of the various particles composing it. In general, this process must be performed by the aid of higher mathematics; and even then, only in those cases in which the bodies are of regular geometrical form.

Moment of Inertia of a Body about an Axis.—Before deducing the expression for the kinetic energy of a rotating body, it may be as well to explain certain terms and quantities which we shall have occasion to make use of.

DEFINITION.—**If the mass of every particle of a body be multiplied by the square of its distance from a given axis, the sum of the products is called the Moment of Inertia of the body about that axis.**

Let I = Moment of inertia of the body about a given axis.
„ m = Mass of any particle or element of body.
„ r = Distance of m from the given axis.

Then, $$I = \Sigma m r^2. \quad \ldots\ldots\ldots \quad (I)$$

DEFINITION.—**If M be the mass of a body, and k be such a quantity that $M k^2$ is its Moment of Inertia about a given axis, then k is called the Radius of Gyration of the body about that axis.**

Thus, $$M k^2 = I$$
Or, $$k^2 = \frac{I}{M} \quad \ldots\ldots\ldots \quad (II)$$

The following PROPOSITIONS relating to moments of inertia and radii of gyration are so important that we here give their proofs in full:—

PROPOSITION I.—**If M be the mass of any body, I_G the moment of inertia about any axis through its centre of gravity, G, and I_O, that about a parallel axis through any other point, O, at a distance, h, from G, then:—**

$$I_O = I_G + M h^2. \quad . \quad . \quad . \quad . \quad . \quad . \quad . \quad (III)$$

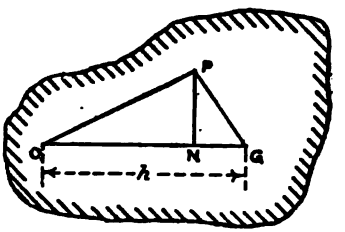

MOMENTS OF INERTIA ABOUT PARALLEL AXES.

Let G, and O, be the points of intersection of the axes with the plane of the paper, which is at right angles to them. Let P be any particle of mass, m. Draw P N perpendicular to O G.

Then, in triangle O P G, we get (Euc. II., 12):—

$$O P^2 = P G^2 + O G^2 - 2 O G \cdot G N.$$

Multiplying both sides by m the mass of particle at P, we get:—

$$m \cdot O P^2 = m \cdot P G^2 + m \cdot O G^2 - 2 m \cdot O G \cdot G N.$$

Repeating this process for every other particle of the body, and adding the results, we have:—

$$\Sigma m \cdot O P^2 = \Sigma m \cdot P G^2 + \Sigma m \cdot O G^2 - 2 \Sigma m \cdot O G \cdot G N.$$

But, clearly, $\Sigma m \cdot O P^2 = I_O$, and $\Sigma m \cdot P G = I_G$.

And, since $O G = h =$ constant,

$\therefore$ $\Sigma m \cdot O G^2 = O G^2 \Sigma m = h^2 M$, or $M h^2$.

Also, $2 \Sigma m \cdot O G \cdot G N = 2 O G \cdot \Sigma m \cdot G N = 2 h \Sigma m \cdot G N.$

But the quantity, $\Sigma m \cdot G N$, is the sum of the moments of the various particles about their centre of gravity, G, and is therefore zero, from the definition of the centre of gravity.

$$\therefore \qquad 2\Sigma m \cdot OG \cdot GN = 2h\Sigma m \cdot GN = 0.$$

$$\therefore \qquad I_O = I_G + M h^2.$$

COROLLARY.—Denoting the radii of gyration of the body about the axes, O, and G, by k_O, and k_G, respectively, we get :—

$$M k_O^2 = M k_G^2 + M h^2.$$

$$\therefore \qquad k_O^2 = k_G^2 + h^2. \quad . \quad . \quad . \quad . \quad . \quad . \quad . \quad \text{(IV)}$$

PROPOSITION II.—If I_x and I_y respectively denote the moments of inertia of a lamina, or plane area, about two axes O X, O Y, at right angles, lying in the plane of the lamina or area, and I_z, the moment of inertia about an axis, O Z, through O, perpendicular to the plane of the lamina or area; then I_z is equal to the sum of I_x, and I_y.

i.e.,

$$I_z = I_x + I_y. \quad . \quad . \quad . \quad . \quad . \quad . \quad . \quad . \quad \text{(V)}$$

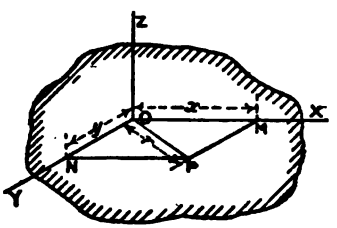

MOMENT OF INERTIA OF LAMINA ABOUT RECTANGULAR AXES.

Take any particle, P, of mass, m, and draw P M, and P N, perpendicular to O X and O Y respectively.

Let x and y denote the co-ordinates of P, with respect to the axes, O X, O Y, so that O M = x, O N = y, and O P = r. Then :—

Moment of inertia of P about O X $= m \cdot PM^2 = m \cdot y^2$.

" " O Y $= m \cdot PN^2 = m \cdot x^2$.

" " O Z $= m \cdot OP^2 = m \cdot r^2$.

But,

$$r^2 = y^2 + x^2,$$

$$\therefore \qquad m \cdot r^2 = m \cdot y^2 + m \cdot x^2.$$

Hence, the moment of inertia of P, about the axis, O Z, is equal to the sum of the moments of inertia of the same particle about the axes, O X, and O Y. But this is equally true for every other particle.

$$\therefore \qquad \Sigma m r^2 = \Sigma m y^2 + \Sigma m x^2.$$

i.e., $$I_z = I_x + I_y.$$

COROLLARY.—Denoting the radii of gyration of the lamina, about the axes by the letters k_x, k_y, k_z, we get :—

$$k_z^2 = k_x^2 + k_y^2. \quad . \quad . \quad . \quad . \quad . \quad . \quad . \quad \text{(VI)}$$

PROPOSITION III.—If I_x, I_y, I_z respectively denote the moments of inertia of any body about three rectangular axes drawn from any point, O, in the body, then the sum, I_x, + I_y, + I_z, is equal to twice the moment of inertia, I_o, of the body about the point, O.

i.e., $$I_x + I_y + I_z = 2\,I_o \quad . \quad . \quad . \quad . \quad . \quad . \quad \text{(VII)}$$

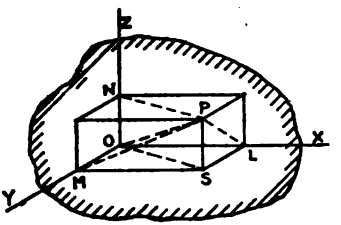

MOMENT OF INERTIA OF BODY ABOUT RECTANGULAR AXES.

Let O X, O Y, O Z be the three rectangular axes drawn from any point, O ; P, any particle of mass m, whose co-ordinates are x, y, z, so that O L = x, O M = y, O N = z, and O P = r. Then :—

Moment of inertia of P about $\Big\}$ $OX = m \cdot PL^2 = m(y^2 + z^2).$

" " $OY = m \cdot PM^2 = m(z^2 + x^2).$

" " $OZ = m \cdot PN^2 = m(x^2 + y^2).$

$$\therefore \qquad I_x = \Sigma m(y^2 + z^2) = \Sigma m y^2 + \Sigma m z^2,$$

$$I_y = \Sigma m(z^2 + x^2) = \Sigma m z^2 + \Sigma m x^2,$$

And, $$I_z = \Sigma m(x^2 + y^2) = \Sigma m x^2 + \Sigma m y^2.$$

$$\therefore \qquad I_x + I_y + I_z = 2\{\Sigma m x^2 + \Sigma m y^2 + \Sigma m z^2\}$$

$$\text{" " } = 2\,\Sigma m(x^2 + y^2 + z^2),$$

i.e., $$I_x + I_y + I_z = 2\,\Sigma m r^2 = 2\,I_o.$$

COROLLARY.—Denoting the radii of gyration of the body about the three axes and the point, O, by the letters k_x, k_y, k_z, and k_o respectively, we get :—

$$k_x^2 + k_y^2 + k_z^2 = 2\,k_o^2 . \quad . \quad . \quad . \quad . \quad \text{(VIII)}$$

Proposition II. is a particular case of this general one. There O P and O S will always coincide, and, therefore, I_z and I_o are identical. By putting $I_o = I_z$ in equation (VII), we at once get equation (V).

Methods of Calculating Moments of Inertia.—We shall show by working out a few examples how the moments of inertia or radii of gyration can be calculated in certain cases, wherein the density is uniform.

EXAMPLE I.—Determine the moment of inertia and radius of gyration of a rectangular lamina (1) about its shorter edge, (2) about an axis in its plane through its *c.g.* and parallel to a short edge, and (3) about an axis through its *c.g.* perpendicular to its plane.

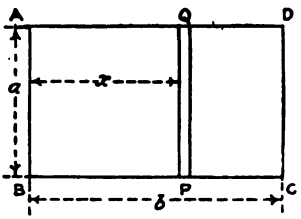

MOMENT OF INERTIA OF RECTANGLE ABOUT AB.

ANSWER.—Let A B C D be the rectangular lamina, and let the edge A B = a, and B C = b.

(1) *About the shorter edge* A B.

Divide the rectangle into n, equal and narrow strips, P Q, parallel to the axis A B.

Let M = Mass of whole figure, A B C D.
" m = Mass of elementary rectangle, P Q.
" x = Distance of P Q from axis A B.
" h = Breadth of elementary strip P Q $= \dfrac{b}{n}$.

The whole of the strip P Q is at the same distance from A B,

$$\therefore \quad \left.\begin{array}{l}\textit{Mom. of inertia of}\\ \textit{element } \text{P Q}\end{array}\right\} = m\,x^2.$$

$$\therefore \quad \left.\begin{array}{l}\textit{Mom. of inertia of}\\ \textit{whole figure}\end{array}\right\} = \Sigma\, m\,x^2.$$

But $\qquad m : \text{M} = h : b.$

$$\therefore \quad m = \frac{\text{M}\,h}{b}.$$

$$\therefore \quad \text{I} = \frac{\text{M}}{b}\,\Sigma\, h\,x^2. \quad . \quad . \quad . \quad . \quad (1)$$

Beginning at edge A B, the distances of the various strips from this edge will be $x_0 = 0$, $x_1 = h$, $x_2 = 2h$, . . . $x_n = nh$.

$$\therefore \quad \Sigma h x^2 = h(0^2 + h^2 + 2^2 h^2 + 3^2 h^2 + \ldots + n^2 h^2),$$

$$\text{,,} \quad = h^3(1^2 + 2^2 + 3^2 + \ldots + n^2),$$

$$\text{,,} \quad = h^3 \frac{n(n+1)(2n+1)}{6}, \text{ [See Treatises on Algebra]}$$

$$\text{,,} \quad = \frac{(nh)^3}{6}\left(1 + \frac{1}{n}\right)\left(2 + \frac{1}{n}\right).$$

When the number of strips, n, is infinitely large, the reciprocal, $\frac{1}{n}$, will be infinitely small, and may, therefore, be neglected.

Also, $$(nh)^3 = b^3.$$

$$\therefore \quad \Sigma h x^2 = \frac{b^3}{6} \times 2 = \tfrac{1}{3} b^3,$$

$\therefore$ From eqn. (1), $\quad I = \frac{1}{3} M b^2.$

Let k = Radius of gyration, then :—

$$M k^2 = I,$$

$$\therefore \quad k^2 = \tfrac{1}{3} b^2,$$

Or, $$k = \frac{b}{\sqrt{3}}.$$

[The above method of finding the moment of inertia is precisely the same as that employed in higher mathematics. For those who understand the calculus we here repeat the above calculation, using its notation.

Let dx = Breadth of elementary strip, P Q.

Then, $$m = \frac{M}{b} dx.$$

$$\therefore \quad dI = \frac{M}{b} x^2 dx.$$

$$\therefore \quad I = \frac{M}{b}\int_0^b x^2 dx = \frac{M}{b}\left[\frac{x^3}{3}\right]_0^b = \frac{M}{b} \cdot \frac{b^3}{3} = \tfrac{1}{3} M b^2.]$$

(2) *About an axis through c.g. parallel to edge* A B.—We may obtain the moment of inertia in this case by proceeding in

exactly the same way as before, but there is no need for this repetition, as we can very easily get the result from the relation given in PROPOSITION I.

Let I_G = Moment of inertia of the rectangle about an axis through its *c.g.* parallel to the edge A B.
" I = Moment of inertia about the edge A B = $\frac{1}{3} M b^2$.
" h = Distance between these axes = $\frac{1}{2} b$.

Then, from equation (III) :—

$$I = I_G + M h^2.$$

$$\therefore \quad I_G = I - M h^2 = \tfrac{1}{3} M b^2 - \tfrac{1}{4} M b^2 = \tfrac{1}{12} M b^2.$$

Also, $$k_G^2 = \tfrac{1}{12} b^2.$$

(3) *About an axis through c.g. perpendicular to plane.*

Moment of inertia about an axis through c.g. parallel to A B $\Big\} = I_x = \frac{1}{12} M b^2.$

Moment of inertia about an axis through c.g. parallel to B C $\Big\} = I_y = \frac{1}{12} M a^2$

But, from equation (V), $$I_z = I_x + I_y.$$

$\therefore$ **Moment of inertia about an axis through *c.g.* perpendicular to the plane** $\Big\} = I_z = \frac{1}{12} M (a^2 + b^2).$

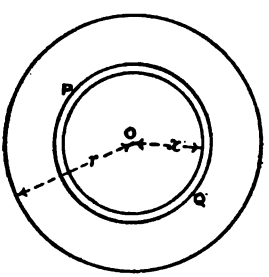

RADIUS OF GYRATION OF A CIRCULAR DISC.

EXAMPLE II.—Determine the radius of gyration of a circular disc about an axis through its centre perpendicular to its plane.

ANSWER.—Divide the disc into n, equal, narrow rings of breadth, h. Taking one of these rings, P Q, let x be its distance from the centre, O.

Let M = Mass of the disc.
" m = Mass of the elementary ring, P Q.
" r = Radius of the disc.

Then, $m : M$ = *area of ring : area of disc.*

i.e., $m : M = 2 \pi x h : \pi r^2.$

$$\therefore \quad m = \frac{2 M}{r^2} x h.$$

The whole of the elementary ring is at the same distance from the centre :—

$$\therefore \quad \left.\begin{array}{l}\textit{Moment of inertia of elementary}\\ \quad\textit{ring about the axis through O}\end{array}\right\} = m\,x^2 = \frac{2\,\mathrm{M}}{r^2}\,x^3\,h.$$

$$\therefore \quad \left.\begin{array}{l}\textit{Moment of inertia of the whole}\\ \quad\textit{disc}\end{array}\right\} = \mathrm{I} = \frac{2\,\mathrm{M}}{r^2}\,\Sigma\,x^3\,h. \qquad (1)$$

Beginning at the centre, O, the distances of the various rings will be $x_0 = 0$, $x_1 = h$, $x_2 = 2h, \ldots x_n = nh$.

$$\therefore \quad \Sigma\,x^3\,h = (0^3 + 1^3\,h^3 + 2^3\,h^3 + \ldots + n^3\,h^3)\,h$$

$$\text{,,} \quad = (1^3 + 2^3 + 3^3 + \ldots + n^3)\,h^4$$

$$\text{,,} \quad = \tfrac{1}{4}\,n^2\,(n+1)^2\,h^4 \qquad \text{[See Treatises on Algebra]}$$

$$\text{,,} \quad = \frac{(n\,h)^4}{4}\cdot\left(1 + \frac{1}{n}\right)^2.$$

When n is infinitely great, the reciprocal, $\frac{1}{n}$, will be infinitely small, and may be neglected.

Also, $$(n\,h)^4 = r^4.$$

$$\therefore \quad \text{From equation (1),} \quad \mathrm{I} = \frac{2\,\mathrm{M}}{r^2} \times \frac{r^4}{4} = \tfrac{1}{2}\,\mathrm{M}\,r^2.$$

$$\therefore \quad k^2 = \tfrac{1}{2}\,r^2. \quad \ldots\ldots\ldots\ldots \quad (2)$$

[These results may also be obtained by the aid of the calculus, thus :—

Let $d\,x$ = Breadth of elementary ring.

Then, $$m = \frac{2\,\mathrm{M}}{r^2}\,x\,d\,x.$$

$$\therefore \quad d\,\mathrm{I} = \frac{2\,\mathrm{M}}{r^2}\,x^3\,d\,x.$$

$$\therefore \quad \mathrm{I} = \frac{2\,\mathrm{M}}{r^2}\int_0^r x^3\,d\,x = \frac{2\,\mathrm{M}}{r^2}\cdot\frac{r^4}{4} = \tfrac{1}{2}\,\mathrm{M}\,r^2.$$

If, however, the disc be annular, the outside and inside radii being R and r respectively, we get :—

$$m = \frac{2\,\mathrm{M}}{\mathrm{R}^2 - r^2}\cdot x\,d\,x.$$

And, $$I = \frac{2M}{R^2 - r^2}\int_r^R x^3\,dx$$

$$\text{,,} = \frac{2M}{R^2 - r^2} \times \frac{R^4 - r^4}{4} = \tfrac{1}{2}M(R^2 + r^2).$$

$$\therefore \quad k^2 = \tfrac{1}{2}(R^2 + r^2).]$$

These results also express the moments of inertia and radii of gyration of a solid and of a hollow cylinder about their axes. For a cylinder can be conceived as made up of a great number of circular discs threaded together on the same axis, and the moment of inertia will just be the sum of the moments of inertia of all the discs, since the radius of gyration of each disc is independent of the thickness of the disc, it follows that the radius of gyration of the whole cylinder will be the same as that of one of the discs.

Having found the radius of gyration of a circular disc about an axis through its centre at right angles to its plane, we can very easily find its radius of gyration about a diameter.

Let k_x, k_y = Radii of gyration of disc about two diameters at right angles to each other.

,, k_z = Radius of gyration about axis through centre and perpendicular to plane.

Then, $$k_x = k_y = k$$

And, from (2) $$k_z^2 = \tfrac{1}{2}r^2.$$

But, from equation (VI), PROPOSITION II., we get:—

$$k_x^2 + k_y^2 = k_z^2.$$

$$\therefore \quad 2k^2 = k_z^2 = \tfrac{1}{2}r^2.$$

$$\therefore \quad k^2 = \tfrac{1}{4}r^2, \text{ or } k = \frac{r}{2}.$$

If the disc be annular and of radii R and r, then the radius of gyration about any diameter, is given by the equation:—

$$k^2 = \tfrac{1}{4}(R^2 + r^2).$$

EXAMPLE III.—Determine the radius of gyration of a sphere about a diameter.

ANSWER.—The results of PROPOSITION III. tell us that if three mutually perpendicular axes be drawn from any point

in a body, the sum of the moments of inertia of the body about these axes is equal to twice the moment of inertia of the body about that point. Suppose, then, that the point selected be the centre of the sphere, the axes will then be three mutually perpendicular diameters. But the moments of inertia about all diameters must be the same. Therefore, if I denote the moment of inertia of the sphere about any diameter and I_0 that about the centre, O, we get, from equation (VII):—

$$3\,I = 2\,I_0 \quad . \quad . \quad . \quad . \quad . \quad . \quad . \quad . \quad . \quad (1)$$

It only remains now to find the value of I_0 or $\Sigma\, m\, x^2$.

Suppose the sphere divided into a large number n, of concentric shells, the thickness of each shell being h.

Let x = Distance of any one shell from centre of sphere.
" r = Radius of sphere.
" m = Mass of shell.
" M = Mass of sphere.

Then, $\quad m : M =$ vol. of shell : vol. of sphere,

i.e., $$m : M = 4\,\pi\, x^2\, h : \frac{4}{3}\,\pi\, r^3,$$

$\therefore$ $$m = \frac{3\,M}{r^3}\, x^2\, h,$$

And, $$I_0 = \Sigma\, m\, x^2 = \frac{3\,M}{r^3}\,\Sigma\, x^4\, h.$$

Beginning at the centre of the sphere and putting successively, $x_0 = 0$, $x_1 = h$, $x_2 = 2\,h$, . . . $x_n = n\,h$, we get :—

$$\Sigma\, x^4\, h = (1^4 + 2^4 + 3^4 + \ldots n^4)h^5,$$

$$\text{"} \quad = \left\{ \frac{n^5}{5} + \frac{n^4}{2} + \frac{n^3}{3} - \frac{n}{30} \right\} h^5,$$

$$\text{"} \quad = \left\{ \frac{1}{5} + \frac{1}{2\,n} + \frac{1}{3\,n^2} - \frac{1}{30\,n^4} \right\} n^5\, h^5.$$

When n is infinitely great, the quantity inside the brackets reduces to $\frac{1}{5}$, and

$$n^5\, h^5 = r^5.$$

$\therefore$ $$\Sigma\, x^4\, h = \tfrac{1}{5}\, r^5.$$

$\therefore$ $$I_0 = \frac{3\,M}{r^3} \times \tfrac{1}{5}\, r^5 = \tfrac{3}{5}\, M\, r^2.$$

$\therefore$ From equation (I) $I = \frac{2}{3} I_0 = \frac{2}{5} M r^2$.

Hence, $$k^2 = \frac{2}{5} r^2.$$

[The same result can be easily arrived at by aid of the Calculus. With the usual notation, we get :—

$$m = \frac{3\,M}{r^3} x^2\, d\,x,$$

$$\therefore \quad I_0 = \Sigma\, m\, x^2 = \frac{3\,M}{r^3} \int_0^r x^4\, d\,x = \frac{3\,M}{r^3} \times \frac{r^5}{5} = \frac{3}{5} M\, r^2,$$

$$\therefore \quad I = \frac{2}{3} I_0 = \frac{2}{5} M r^2.]$$

If the sphere be hollow, the inside radius being r, and the outside radius R, it can easily be proved that :—

$$I = \frac{2}{5} M \frac{R^5 - r^5}{R^3 - r^3}.$$

The term "moment of inertia" has been defined above with respect to a solid body only, but it is easy to see that by a slight alteration in the wording of the definition it may be made to apply equally to an area or a *section* of a solid. Accordingly, we find the terms "moment of inertia" and "radius of gyration" applied to areas as well as to solids. Thus, we speak about the moment of inertia and radius of gyration of a circle about a diameter, a triangle about its base, and so on.

We may here remark that the moment of inertia of a solid, or section of a solid, about a given axis, is always proportional to the mass of the solid, or to the area of the section as the case may be.

The following rule has been stated by Routh and will be found useful for finding the moments of inertia about an axis of symmetry :—

Moment of Inertia = *Mass* × (*sum of the squares of the perpendicular semi-axes*) ÷ (3, 4, *or* 5, *according as the body is rectangular, elliptical, or ellipsoidal*).

For the sake of reference, we here give tables of the squares of the radii of gyration for some of the more important cases of both solids and sections.

In every case the axis is taken as passing through the centre of mass of the solid or centre of area of the section, so that if the moment of inertia or radius of gyration be required about any other axis, this can easily be computed from the results given in PROPOSITIONS I., II., and III.

TABLE I.—SQUARES OF RADII OF GYRATION OF SOLIDS.

	Name of Solid, and Dimensions.	Position of Axis through c.g.	Square of Radius of Gyration. $k^2 = \frac{I}{M}$
I.	Circular hoop of thin wire —Radius, r	Perp. to plane of circle	r^2
II.	Circular hoop of thin wire —Radius, r	About a diameter	$\frac{1}{2} r^2$
III.	Uniform circular rod—Length, l; radius, r	Perp. to length	$\frac{1}{12} l^2 + \frac{1}{4} r^2$
IV.	Solid circular cylinder—Radius, r	About its own axis	$\frac{1}{2} r^2$
V.	Hollow circular cylinder or ring—Radii, R, r	About its own axis	$\frac{1}{2} (R^2 + r^2)$
VI.	Thin cylindrical shell—Radius, r	About its own axis	r^2
VII.	Solid sphere—Radius, r	About a diameter	$\frac{2}{5} r^2$
VIII.	Hollow sphere—Radii, R, r	About a diameter	$\frac{2}{5} \frac{R^5 - r^5}{R^3 - r^3}$
IX.	Thin spherical shell—Radius, r	About a diameter	$\frac{2}{3} r^2$
X.	Solid cone—Radius of base, r	About its own axis	$\frac{3}{10} r^2$

TABLE II.—SQUARES OF RADII OF GYRATION OF LAMINA AND SURFACES OR SECTIONS.

	Form of Lamina, Surface, or Section.	Position of Axis through c.g.	Square of Radius of Gyration. $k^2 = \frac{I}{A}$
I.	Rectangle—Sides, a, b	Parallel to side, b	$\frac{1}{12} a^2$
II.	Rectangle—Sides, a, b	Perp. to plane of figure	$\frac{1}{12} (a^2 + b^2)$
III.	Hollow rectangle—Sides, A, B, and a, b	Parallel to sides, B, b	$\frac{1}{12} \frac{A^3B - a^3b}{AB - ab}$
IV.	Triangle — Altitude, a; base, b	Parallel to base, b	$\frac{1}{18} a^2$
V.	Circular section—Radius, r	Perp. to plane of figure	$\frac{1}{2} r^2$
VI.	Circular section—Radius, r	About a diameter	$\frac{1}{4} r^2$
VII.	Hollow circular section—Radii, R, r	Perp. to plane of figure	$\frac{1}{2} (R^2 + r^2)$
VIII.	Hollow circular section—Radii, R, r	About a diameter	$\frac{1}{4} (R^2 + r^2)$
IX.	Elliptical section—Axes, a, b	About axis, b	$\frac{1}{16} a^2$
X.	Elliptical section—Axes, a, b	Perp. to plane of figure	$\frac{1}{16} (a^2 + b^2)$
XI.	Hollow elliptical section—Axes, A, B, and a, b	About axis, B, b	$\frac{1}{16} \frac{A^3B - a^3b}{AB - ab}$

Equation of Energy for a Rotating Body.—We shall now determine the energy possessed by a rotating body.

Let W = Weight of body, and M its mass.
" w = Weight of any particle at a distance, r, from the axis of rotation, and m its mass.
" ω = Angular velocity of body about given axis.
" v = Linear velocity of the particle = ωr.
" k = Radius of gyration about the given axis.

Then, the kinetic energy of the particle $= \frac{w v^2}{2g} = \frac{w \omega^2 r^2}{2g}$.

Repeating this process for every particle composing the body, and adding the results together, we get:—

$$\left.\begin{array}{l}\text{The kinetic energy of}\\ \text{the whole body, } E_K\end{array}\right\} = \Sigma \frac{w \omega^2 r^2}{2g} = \frac{\omega^2}{2g} \Sigma w r^2 = \frac{\omega^2}{2} \Sigma m r^2,$$

since $w = m g$, and ω is the same for every particle.

But, $$\Sigma m r^2 = I = M k^2 = \frac{W k^2}{g}, \text{ about the given axis,}$$

$$\therefore \quad E_K = \tfrac{1}{2} I \omega^2 = \frac{W \omega^2 k^2}{2g} \quad . \quad . \quad . \quad . \quad (IX)^*$$

Thus, the equation for the energy of a body rotating about a fixed axis is similar in form to that for a body moving without rotation.

Engineers usually measure the angular velocity of a rotating body by the number of revolutions made in unit time.

Then, if n be the number of revolutions per unit time,

$$\omega = 2 \pi n$$

$$\therefore \quad E_K = \frac{W \times 4 \pi^2 n^2 k^2}{2g} = \frac{2 \pi^2 n^2 W k^2}{g} \quad . \quad . \quad . \quad . \quad (X)$$

We may also show, as in the previous Lecture, that, if the angular velocity changes from ω_1 to ω_2, or from n_1 to n_2 revolutions per second, then:—

* If W be expressed in absolute units or poundals, the kinetic energy will also be given in absolute units or foot-poundals; but if W be in pounds weight or in gravitation units, then the kinetic energy will be in foot-pounds.

The student should note that the *pound* is the absolute unit of mass, and, therefore, those of the above equations which contain M instead of $\frac{W}{g}$ *always* give the kinetic energy in absolute units or foot-poundals.

$$\left.\begin{array}{ll}\text{The change of kinetic energy} & = \dfrac{W(\omega_2^2 - \omega_1^2)k^2}{2g} \\ \text{Or, } \quad \text{,,} \quad \text{,,} & = \dfrac{2\pi^2 W(n_2^2 - n_1^2)k^2}{g}\end{array}\right\} \quad . \quad . \quad (XI)$$

Again, if the centre of gravity of the body be moving with a linear velocity, v, and if at the same time the body be rotating about an axis through its centre of gravity with an angular velocity, ω, then the total kinetic energy possessed by the body is :—

$$E_K = \frac{W v^2}{2g} + \frac{W \omega^2 k^2}{2g} = \frac{W}{2g}\{v^2 + \omega^2 k^2\}. \quad . \quad (XII)$$

Or, if the linear velocity changes from v_1 to v_2, while the angular velocity changes from ω_1 to ω_2, then the total change in the kinetic energy of the body during that period is :—

$$\frac{W(v_2^2 - v_1^2)}{2g} + \frac{W(\omega_2^2 - \omega_1^2)k^2}{2g} = \frac{W}{2g}\{(v_2^2 - v_1^2) + (\omega_2^2 - \omega_1^2)k^2\}. \quad (XIII)$$

EXAMPLE IV.—Sketch and describe the action of a fly-press as used for punching holes in metal plates. The balls weigh 60 lbs. each, and are fixed at a radius of 30 inches from the axis of the screw. The screw is double threaded, and of 1 inch pitch. Find what diameter of hole can be punched in a wrought iron plate $\frac{3}{8}$ inch thick, if the strength of the plate in shear be taken at 22 tons per square inch, the resistance to shearing be overcome in the first $\frac{1}{16}$ inch, and if the balls at the instant when the punch touches the plate are moving at the rate of 60 revolutions per minute.

ANSWER.—For a sketch and description of a fly-press, the student may refer to Lecture XXI., of the Author's *Elementary Manual on Applied Mechanics.*

Let W = Weight of *each* ball = 60 lbs.
,, k = Radius of gyration of the system = $2\frac{1}{2}$ feet.
,, n = Number of revolutions *per second* = 1.
,, R = Resistance, in lbs., offered by the metal to the punch.
,, s = Distance through which R is overcome = $\frac{1}{16}$ inch $= \dfrac{1}{12 \times 16}$ feet.
,, t = Thickness of plate punched = $\frac{3}{8}$ inch.
,, d = Diameter, in inches, of the hole.
,, f = Resistance of metal to shearing = 22 × 2240 lbs. per square inch.

Then, $\textit{Area sheared} = \left\{ \begin{array}{l} \textit{Area of cylindrical surface of} \\ \textit{hole} = \pi\, d\, t. \end{array} \right.$

$\therefore$ $\left.\begin{array}{l}\textit{Mean resistance offered} \\ \textit{to shearing}\end{array}\right\} = \mathrm{R} = \pi\, d\, t\, f.$

$\therefore$ $\textit{Work done against } \mathrm{R} = \mathrm{R} \times s = \pi\, d\, t\, f \times s.$

But, $\textit{Work done against } \mathrm{R} = \left\{ \begin{array}{l} \textit{Energy of moving balls at the} \\ \textit{instant when punch strikes} \\ \textit{metal} \end{array} \right.$

$$\text{,, \quad ,,} \quad = \frac{2\,\mathrm{W}\,v^2}{2\,g} = \frac{\mathrm{W} \times 4\,\pi^2\,n^2\,k^2}{g}$$

$$\therefore \qquad \pi\, d\, t\, f \times s = \frac{\mathrm{W} \times 4\,\pi^2\,n^2\,k^2}{g}.$$

This is the general equation connecting together the given and the required quantities. By substituting the given data, and cancelling π from both sides of the equation, we get :—

$$d \times \tfrac{3}{8} \times 22 \times 2240 \times \frac{1}{12 \times 16} = \frac{60 \times 4 \times \frac{22}{7} \times 1 \times 1 \times 2\tfrac{1}{2} \times 2\tfrac{1}{2}}{32}$$

$$\therefore \qquad d = 1{\cdot}53 \text{ inch.}$$

EXAMPLE V.—A flywheel weighing 4 tons is keyed to a shaft of 9 inches diameter at the journals. The radius of gyration of the wheel is $5\frac{1}{4}$ feet. At a given instant the wheel is found to be making 80 revolutions per minute, and is not acted on by any other retarding forces than the friction at its journals. Find (1) the reduction in speed after the wheel has made 100 turns. (2) The number of turns it will make before it stops if the coeff. of friction between the journals and their bearings = 0·07.

ANSWER.—(1) To find the reduction in speed after the wheel has made 100 turns, we must equate the work done against friction in 100 turns to the change of kinetic energy of the wheel during that time.

Let W = Weight of wheel = 4 tons = 4 × 2,240 lbs.
,, k = Radius of gyration of wheel = $5\frac{1}{4}$ ft.
,, n_1, n_2 = Initial and final revolutions per second.
,, d = Diameter of journals = $\frac{3}{4}$ ft.
,, μ = Coefficient of friction = 0·07.

Using equation (XI), we have :—

$$\textit{Change of } \mathrm{E_K} \textit{ of wheel} = \frac{2\,\pi^2\,(n_1^2 - n_2^2)\,\mathrm{W}\,k^2}{g}.$$

And, from equation (II_b), Lecture VII., Vol. I. :—

Work lost in friction in one turn of journals $= \pi d \mu R$.

Where R is the resultant pressure on the bearings, and therefore = W in this case.

$$\therefore \left.\begin{array}{l}\textit{Work done against fric-}\\ \textit{tion in 100 turns}\end{array}\right\} = 100 \pi d \mu W.$$

$$\therefore \quad \frac{2 \pi^2 (n_1^2 - n_2^2) W k^2}{g} = 100 \pi d \mu W.$$

$$\therefore \quad n_1^2 - n_2^2 = \frac{100 d \mu g}{2 \pi k^2}.$$

Hence,
$$n_2^2 = n_1^2 - \frac{50 d \mu g}{\pi k^2}$$

$$\therefore \quad \text{,,} = \left(\frac{80}{60}\right)^2 - \frac{50 \times \cdot 75 \times \cdot 07 \times 32}{\frac{22}{7} \times 5 \cdot 25 \times 5 \cdot 25}$$

$$\text{,,} = 1 \cdot 78 - \cdot 97 = \cdot 81.$$

Or,
$$n_2 = \sqrt{\cdot 81} = \cdot 9 \text{ rev. per sec., or } 54 \text{ revs. per min.}$$

$$\therefore \quad \textbf{Reduction in speed} = n_1 - n_2 = 80 - 54 = \textbf{26 revs. per min.}$$

(2) Let n = number of turns made before stopping.

Then, in this case, the whole energy of the wheel when making 80 turns per minute is absorbed in friction at the journals.

$$\therefore \quad \frac{2 \pi^2 n_1^2 W k^2}{g} = n \pi d \mu W.$$

$$\therefore \quad n = \frac{2 \pi n_1^2 k^2}{\mu d g} = \frac{2 \times \frac{22}{7} \times \frac{80}{60} \times \frac{80}{60} \times 5 \cdot 25 \times 5 \cdot 25}{\cdot 07 \times \cdot 75 \times 32}$$

$$\therefore \quad n = 183\tfrac{1}{3} \text{ turns.}$$

EXAMPLE VI.—A right cylinder of radius r, rolls, without slipping, down an inclined plane of height h. Find its velocity at the foot of the plane, and compare this with that which it-

would have had by merely sliding. Neglect frictional resistances in both cases.

ANSWER.—Let v = Velocity of *c.g.* of cylinder at foot of plane.
" ω = Angular velocity " "
" W = Weight of cylinder.
" k = Radius of gyration about its own axis $= \frac{r}{\sqrt{2}}$.

Then, $\left.\begin{array}{l}\textit{Total kinetic energy}\\ \textit{at foot of plane}\end{array}\right\} = \left\{\begin{array}{l}\textit{Energy of Translation}\\ +\textit{Energy of Rotation.}\end{array}\right.$

But, $\left.\begin{array}{l}\textit{Total energy at foot}\\ \textit{of plane}\end{array}\right\} = \mathrm{W}\,h.$

Also, $\textit{Energy of Translation} = \frac{\mathrm{W}\,v^2}{2\,g}.$

And, $\textit{Energy of Rotation} = \frac{\mathrm{W}\,\omega^2\,k^2}{2\,g}.$

$\therefore \quad \mathrm{W}\,h = \frac{\mathrm{W}\,v^2}{2\,g} + \frac{\mathrm{W}\,\omega^2\,k^2}{2\,g}. \quad \therefore \quad 2\,g\,h = v^2 + \omega^2\,k^2.$

But, $\omega = \frac{v}{r}$, and $k = \frac{r}{\sqrt{2}}. \quad \therefore \quad \omega^2\,k^2 = \frac{v^2}{2}.$

$\therefore \quad 2\,g\,h = v^2 + \frac{v^2}{2}. \quad \therefore \quad v = \sqrt{\frac{4\,g\,h}{3}}.$

Had the cylinder been allowed to *slide* down the plane *without rolling*, the velocity at foot of plane would have been :—

$$v = \sqrt{2\,g\,h}.$$

$\therefore$ $\left.\begin{array}{l}\text{Vel. with rolling : Vel.}\\ \text{without rolling}\end{array}\right\} = \sqrt{\frac{4\,g\,h}{3}} : \sqrt{2\,g\,h} = \sqrt{2} : \sqrt{3}.$

Of course, the kinetic energy of the body in both cases is the same, but in the second case the whole energy is translational, hence the reason for the greater speed in this case.

EXAMPLE VII.—A weight, Q, draws up another weight, W, by means of an ordinary wheel and axle. The force ratio (Q : W) is 1 to 6, and the velocity ratio (vel. of Q : vel. of W) is 8 to 1. The diameter of the axle is 6 inches, and the radius

of gyration of the wheel and its axle may be taken at 10 inches. Neglecting frictional resistances and the inertia of the ropes, determine the revolutions per minute of the machine after 10 turns have been made from a state of rest. Take the weight of the wheel and its axle = 2 W.

ANSWER.—We shall first answer this question in a general way.

Let W_1 = Weight of wheel and axle.
" V = Velocity of effort, Q, in ft. per sec., after N turns.
" v = Velocity of weight, W, " "
" R = Radius of wheel in feet.
" r = Radius of axle "
" k = Radius of gyration of wheel and axle in feet.
" n = Revolutions per sec. of machine, after N turns.

Then, by the *Principle of Energy*, we get :—

Energy exerted = Work done + Change of kinetic energy.

But, *Energy exerted* = Q × *Distance fallen in* N *turns of machine.*

" $= Q \times 2\pi R N.$

Work done = W × *Distance raised in* N *turns of machine* $= W \times 2\pi r N.$

Change of kinetic energy = *Translational energy of* Q *and* W + *Rotational energy of wheel and axle.*

$$\text{" "} = \frac{4\pi^2 n^2 Q \times R^2}{2g} + \frac{4\pi^2 n^2 W \times r^2}{2g} + \frac{4\pi^2 n^2 W_1 \times k^2}{2g}$$

$$\text{" "} = \frac{2\pi^2 n^2}{g}\left\{ Q R^2 + W r^2 + W_1 k^2 \right\}$$

Hence, $Q \times 2\pi R N = W \times 2\pi r N + \frac{2\pi^2 n^2}{g}\left\{ QR^2 + Wr^2 + W_1 k^2 \right\}$

Or, $(QR - Wr)N = \frac{\pi n^2}{g}\left\{ Q R^2 + W r^2 + W_1 k^2 \right\}$

This is the general expression from which n can be found when the other quantities are given.

From the question, we get :—$W = 6Q$; $W_1 = 2W = 12Q$; $N = 10$; $V = 8v$; $r = 3$ inches $= \frac{1}{4}$ foot; $R = \frac{V}{v} r = 8 \times \frac{1}{4} = 2$ feet; $k = \frac{10}{12} = \frac{5}{6}$ foot.

$$\text{Hence, } \left.\begin{matrix}\textit{Energy}\\ \textit{exerted}\end{matrix}\right\} = Q \times 2\pi RN = Q \times 2\pi \times 2 \times 10 = 40\pi Q \textit{ ft.-lbs.}$$

$$\textit{Work done} = W \times 2\pi r N = 6Q \times 2\pi \times \tfrac{1}{4} \times 10 = 30\pi Q \quad ,,$$

$$\left.\begin{matrix}\textit{Change of kinetic}\\ \textit{energy}\end{matrix}\right\} = \frac{2\pi^2 n^2}{g}\left\{ Q R^2 + W r^2 + W_1 k^2 \right\}$$

$$,, \quad ,, \quad = \frac{2\pi^2 n^2}{32}\left\{ Q \times 2^2 + 6Q \times (\tfrac{1}{4})^2 + 12Q \times (\tfrac{5}{6})^2 \right\} ,,$$

$$,, \quad ,, \quad = \frac{\pi^2 n^2}{16} \times \frac{305}{24} Q \textit{ ft.-lbs.}$$

$$\therefore \quad 40\pi Q = 30\pi Q + \frac{305\pi^2 n^2}{16 \times 24} Q.$$

$$\therefore \quad n^2 = \frac{10 \times 16 \times 24}{305 \times \frac{22}{7}} = 4.$$

$\therefore$ n = **2 revolutions per second, or 120 per min.**

Determination of the Energy of Flywheels.—Before the energy of a rotating body can be calculated at any given speed, it is necessary to know the radius of gyration of that body about the given axis of rotation. We have already shown how this quantity can be calculated in certain bodies which are of regular geometrical form; but many cases occur in the rotating parts of machines where the above methods of calculation would be most difficult, if not altogether impossible. Such is the case with most flywheels. The flywheel is a most important part of an engine, since it is a regulator of the speed. Owing to the great mass of its rim it naturally possesses great inertia, and is, therefore, capable of storing up a considerable amount of the energy developed in the cylinder, and of again imparting this stored energy to the moving parts during those portions of a revolution when the work done in the cylinder is less than the work being done outside. It is important to know the radius of gyration of the wheel, so that calculations relating to the storage and output of its energy can be effected. This radius of the wheel may be determined either approximately by calculation, or accurately by experimenting on the wheel itself, or with another similarly shaped wheel. We shall deal with these cases in turn.

(1) *By Approximate Calculation.*—Most flywheels consist of a heavy rim with comparatively light arms and nave; hence,

in calculations relating to the radii of gyration of such wheels, we may neglect the effects of the arms and nave, and consider only that of the heavy rim. Usually the rim is of a rectangular cross section.

Let R, r = Outside and inside radii of rim.

Then, from Table I., case V., of this Lecture, we get:—

$$k^2 = \tfrac{1}{2}(R^2 + r^2).$$

Substituting this in the equation for the kinetic energy of the wheel, we may obtain an approximate result.

Many engineers, however, further simplify their formula by taking for the radius of gyration the *mean* radius of the rim, and consider this quite near enough for most purposes. Thus:—

$$k = \tfrac{1}{2}(R + r).$$

The difference in the kinetic energy, as calculated from those two assumptions, may be shown as follows:—

Let W = Total weight of wheel.
" ω = Angular velocity of wheel

Then, according to the *first* assumption:—

$$\textit{The kinetic energy} = \frac{W\,\omega^2 k^2}{2g} = \frac{W\,\omega^2}{2g} \times \frac{R^2 + r^2}{2}.$$

And, according to the *second* assumption:—

$$\text{The kinetic energy} = \frac{W\,\omega^2}{2g} \times \frac{(R + r)^2}{4}.$$

$$\text{Hence, the difference} = \frac{W\,\omega^2}{2g}\left\{\frac{R^2 + r^2}{2} - \frac{(R + r)^2}{4}\right\}$$

$$\text{" \quad "} = \frac{W\,\omega^2}{2g} \times \frac{(R - r)^2}{4}.$$

That is, the kinetic energy in the *first* case is greater than that in the *second* case by $\frac{W\,\omega^2}{2g} \times \frac{(R - r)^2}{4}$. This difference, however, becomes less as $R - r$ diminishes—that is, as r approaches R. On the other hand, it gets greater the thicker the rim. The radius of gyration in the first case—viz., $k^2 = \frac{1}{2}(R^2 + r^2)$, is too great; because the effect of the arms

and nave is to reduce that radius, whereas the other result, $k = \frac{1}{2}(R + r)$, may be too small. It sometimes happens that a closer approximation may be obtained by taking the arithmetical *mean* of the above results, thus :—

$$\left.\begin{array}{c}\text{The kinetic energy}\\ \text{of the wheel}\end{array}\right\} = \frac{W\,\omega^2}{2\,g} \times \frac{1}{2}\left\{\frac{R^2 + r^2}{2} + \frac{(R + r)^2}{4}\right\}$$

$$\text{,,} \qquad \text{,,} \qquad = \frac{W\,\omega^2}{2\,g} \times \frac{\{3\,(R + r)^2 - 4\,R\,r\}}{8}. \quad \text{(XIV)}$$

(2) *By Experiment on the Wheel.*—When accurate results are required, we may determine the radius of gyration of the wheel experimentally as follows :—

Disconnect the flywheel and its shaft from all other moving pieces, and see that the shaft runs smoothly in its bearings. Fit a flat pulley on the shaft and wind a few turns of flexible rope in a single layer round the same.* To the free end of this rope attach a weight sufficiently heavy to cause the flywheel to rotate at a uniform speed when started by the hand. This weight should just supply the energy absorbed by the friction of the shaft in its bearings and the bending of the rope. Now rewind the rope on the pulley and add another weight to its free end, so that the wheel will now start rotating when the weights are allowed to fall. Note the time taken by the weights in falling a known distance. The height through which the weights fall, and the diameter of the pulley being known, it is easy to calculate both the speed of the wheel and the falling weights, and hence their kinetic energies at the instant when the latter reach the ground.

Another method of allowing for the friction of the bearings, &c., is to use only one weight. Note the exact number of turns which the wheel makes (after the weight has ceased to act) until it comes to rest. Then neglecting the atmospheric resistance (which will be very small in an experiment of this kind) the work absorbed at the bearings will be equal to the kinetic energy of the wheel at the instant when the weight ceases to act.

These methods will be better understood when stated thus :—

* If the flywheel shaft be of sufficient diameter, this pulley may be dispensed with, and the rope need then be simply wound round the shaft. If a convenient direct drop for the weights cannot be arranged for, then the rope may pass round a guide pulley fixed to the roof, but in this case the kinetic energy of this pulley must be allowed for.

Let W = Weight of flywheel *in lbs.*
" w = Weight producing motion of wheel.
" w_1 = Weight required to balance friction.
" k = Radius of gyration of flywheel *in feet.*
" h = Height through which w and w_1 fall *in feet.*
" D = Diameter of pulley keyed to shaft *in feet.*
" d = Diameter of rope *in feet.*
" t = Time taken by weight, w, in falling to the ground *in seconds.*
" n = Number of revolutions *per second* which wheel is making at instant when w reaches the ground.
" v = Velocity with which w and w_1 strike the ground.
" N = Number of revolutions made by wheel after w ceases to act.

FIRSTLY.—*When w_1 is employed to balance the frictional resistances.* All the energy exerted by w is employed in giving kinetic energy to the wheel.

But, *Energy exerted* = $w\,h$.

And, $$\left.\begin{matrix}\textit{Change}\\ \textit{of kinetic}\\ \textit{energy}\end{matrix}\right\} = \left\{\begin{matrix}\textit{Kinetic}\\ \textit{energy of}\\ \textit{wheel}\end{matrix}\right\} + \left\{\begin{matrix}\textit{Kinetic energy of } w \textit{ and}\\ w_1 \textit{ when they reach}\\ \textit{the ground}\end{matrix}\right.$$

$$\text{"} \quad = \frac{W \times 4\,\pi^2\,n^2\,k^2}{2\,g} + \frac{(w + w_1)\,v^2}{2\,g}.$$

$$\therefore \qquad w\,h = \frac{W \times 4\,\pi^2\,n^2\,k^2}{2\,g} + \frac{(w + w_1)\,v^2}{2\,g} \quad . \quad . \quad (1)$$

The revolutions, n, and the linear velocity, v, of the falling body at the instant when the latter reaches the ground can be determined as follows, when t, D, and d are known :—

$$\left.\begin{matrix}\textit{Number of revols. made by}\\ \textit{wheel during action of } w\end{matrix}\right\} = \frac{h}{\pi\,(D + d)} \quad . \quad . \quad . \quad . \quad . \quad . \quad . \quad (2)$$

$$\therefore \quad \left.\begin{matrix}\textit{Average number of}\\ \textit{revols. per second}\end{matrix}\right\} = \frac{h}{\pi\,(D + d)\,t}$$

$\therefore$ n = *Twice the average,*

$$\text{"} = \frac{2\,h}{\pi\,(D + d)\,t} \quad . \quad . \quad . \quad . \quad . \quad . \quad . \quad (3)$$

Similarly v = *Twice average linear velocity of w and w_1,*

$$\text{"} = \frac{2\,h}{t} \quad . \quad . \quad . \quad . \quad . \quad . \quad . \quad . \quad . \quad . \quad (4)$$

$\therefore$ From equation (1) we get :—

$$w\,h = \frac{W \times 4\pi^2 \times 4h^2 \times k^2}{2g \times \pi^2 (D + d)^2 t^2} + \frac{(w + w_1) \times 4h^2}{2g \times t^2}$$

$$\therefore \quad \frac{8\,W\,h\,k^2}{g\,(D + d)^2\,t^2} = w - \frac{2\,(w + w_1)\,h}{g\,t^2}. \quad . \quad . \quad (XV)$$

SECONDLY.—*When the number of turns made by wheel after w ceases to act is known,*

$$\textit{Energy exerted} = w\,h.$$

$$\left.\begin{array}{l}\textit{Work done on friction during last N revolutions of wheel}\end{array}\right\} = \left\{\begin{array}{l}\textit{Kinetic energy of wheel at instant when } w \textit{ ceases to act}\end{array}\right.$$

$$\text{,,} \qquad \text{,,} \qquad = \frac{W \times 4\,\pi^2\,n^2\,k^2}{2\,g}.$$

But, by equation (2), the wheel makes $\frac{h}{\pi\,(D + d)}$ revolutions during the action of w.

$$\therefore \left.\begin{array}{l}\textit{Work done on friction during action of } w\end{array}\right\} = \frac{W \times 4\,\pi^2\,n^2\,k^2}{2\,g} \times \frac{\frac{h}{\pi\,(D + d)}}{N}.$$

From equation (3), we get :—

$$n = \frac{2\,h}{\pi\,(D + d)\,t}.$$

$$\therefore \quad \textit{Work done} = \frac{W \times 4\,\pi^2 \times \frac{4\,h^2}{\pi^2\,(D + d)^2\,t^2} \times k^2}{2\,g} \times \frac{h}{\pi\,(D + d)\,N}$$

$$\text{,,} \qquad = \frac{8\,W\,h^3\,k^2}{g\,\pi\,(D + d)^3\,t^2\,N}.$$

$$\left.\begin{array}{l}\textit{Change of kinetic energy}\end{array}\right\} = \frac{W \times 4\,\pi^2\,n^2\,k^2}{2\,g} + \frac{w\,v^2}{2\,g}$$

$$\text{,,} \qquad = \frac{8\,W\,h^2\,k^2}{g\,(D + d)^2\,t^2} + \frac{2\,w\,h^2}{g\,t^2}.$$

$$\text{Hence,} \qquad w\,h = \frac{8\,W\,h^3\,k^2}{g\,\pi\,(D + d)^3\,t^2\,N} + \frac{8\,W\,h^2\,k^2}{g\,(D + d)^2\,t^2} + \frac{2\,w\,h^2}{g\,t^2}.$$

$$\therefore \frac{8\,W\,h\,k^2}{g\,(D + d)^2\,t^2}\left\{\frac{h}{\pi\,(D + d)\,N} + 1\right\} = w\left\{1 - \frac{2\,h}{g\,t^2}\right\}. \quad (XVI)$$

Equations (XV) and (XVI) enable us to find the radius of gyration, k, when the data are furnished by experiment.

If the wheel whose radius of gyration has to be found cannot be conveniently experimented on, then the radius of gyration of another similar wheel may be determined, and that for the first wheel calculated therefrom. It is easy to show generally that the moments of inertia of two similar bodies rotating about similarly placed axes are as the fifth powers of their like linear dimensions.

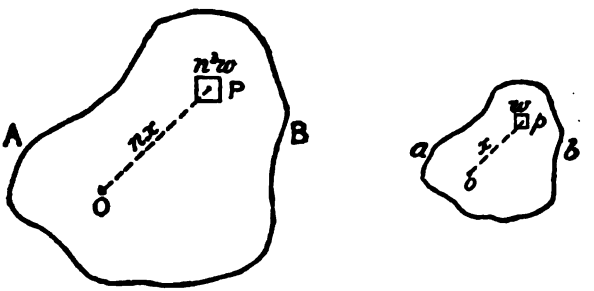

MOMENTS OF INERTIA OF SIMILAR BODIES.

Let A B, and $a\,b$, be any two similar bodies whose axes O, and o, are similarly situated. Let the linear dimensions of the larger body be n times those of the smaller. Taking similar parts at P, and p, so that P is n times as large as p in each direction, it is evident that their masses will be in the proportion of $n^3 : 1$.

i.e., Mass of element at P : *Mass of corresponding element at* p $= n^3 m : m$. Also, if $o\,p = x$, then O P $= n\,x$.

$\therefore$ *Mom. of inertia of* A B *about* O $= \Sigma\, n^3 m \times (n\,x)^2 = n^5\, \Sigma\, m\, x^2$,

and, *Mom of inertia of* $a\,b$ *about* O $= \Sigma\, m\, x^2$.

$$\therefore \quad \left.\begin{array}{r}\text{Mom. of inertia of A B :}\\ \text{Mom. of inertia of } a\,b\end{array}\right\} = n^5 : 1. \quad . \quad . \quad . \quad . \quad \text{(XVII)}$$

Thus, if two flywheels are made from the same drawing, but the scale in the one case be 4 inches to the foot, and in the other $1\frac{1}{2}$ inches to the foot, then their like linear dimensions will be inversely as the scales to which they are drawn, that is :—

Size of first wheel : Size of second wheel $= 1\frac{1}{2} : 4 = 3 : 8$.

$\therefore$ **Mom. of inertia of first wheel : Mom. of inertia of second wheel** $= 3^5 : 8^5 = 243 : 32768 =$ **1 : 134·8 nearly.**

Centripetal and Centrifugal Force.—If a body is observed to be moving in a curvilinear path, either with uniform or variable speed, we at once infer that it is being continually acted upon by some deviating force directed towards the inside of the curve. In the case of a body moving in a circular path, that deviating force must be directed towards the centre of the circle. Hence, a body may be made to move in a circular path either by having it attached to a fixed point (the centre) by an inextensible string, or by compelling it to move in a circular groove. The necessary deviating force is supplied in the first case by the string attached to the body, while in the second case it is supplied by the sides of the groove. In either case this centrally-directed force is called the **Centripetal Force**, while its reaction is called the **Centrifugal Force**. These terms may be defined as follows :—

DEFINITION.—**Centripetal Force is that force which a guiding body exerts on a revolving body in order to compel the revolving body to move in its curvilinear path, and is always directed towards a fixed centre.**

DEFINITION.—**Centrifugal Force is the force with which a revolving body reacts on the body that constrains it to move in a curved path, and is equal and opposite in direction to the force with which the constraining body acts on the revolving body.**

i.e., **Centripetal Force = Centrifugal Force.**

We stated in Lecture XX. that when the velocity of a body changes, whether in magnitude or in direction, the velocity is said to be accelerated, and we have there shown how to measure this acceleration in the case of a particle moving with uniform speed in a circle. Thus, the radial or centripetal acceleration is there shown to be :—

$$a = \frac{v^2}{r}.$$

Where, v = Linear velocity of the particle in the circle,

and, r = Radius of the circle.

But an acceleration of a body can only be produced by the action of some force on it, and in the last Lecture we have shown how this force is measured when the weight of the body and the acceleration are known. Hence :—

$$F = \frac{w}{g} a.$$

Let w = Weight of particle moving uniformly in a circle.
" v = Linear velocity of particle in circle.
" r = Radius of circle.
" F = Centripetal or centrifugal force.
" a = Centripetal acceleration $= \frac{v^2}{r}$.

Then, $$F = \frac{w}{g} a = \frac{w v^2}{g r} \quad . \quad . \quad . \quad . \quad \text{(XVIII)}$$

We may, however, establish the same result in a different manner as follows :—

Let P be the position of the particle at any instant, and Q its position after a small interval of time, t. If no force acted on the body during that small interval of time, it would move along the tangent P T, and at the end of the interval be found at T, such that :—

$$PT = v t.$$

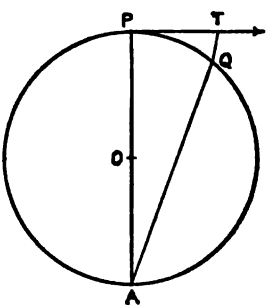

CENTRIPETAL FORCE.

But Q is its actual position ; therefore T Q represents the deviation due to the centripetal force during that interval of time. Join Q A.

Then, $TQ = \frac{1}{2} a t^2$.

But, since P T and Q T are very small, T Q A will be very nearly a straight line.

$$\therefore \quad PT^2 = TA \times TQ \qquad [\text{Euc. III., 35}]$$
$$" \quad = (QA + TQ) \times TQ$$
$$" \quad = QA \times TQ + TQ^2.$$

In the limit, when t is infinitely small and, therefore, Q infinitely near to P, we may neglect TQ^2, and put $QA = PA = 2r$.

$$\therefore \quad v^2 t^2 = 2r \times \tfrac{1}{2} a t^2,$$

$$\therefore \quad a = \frac{v^2}{r}.$$

This is the same result as obtained by means of the Hodograph in Lecture XX.

$$\therefore \qquad \text{Centrifugal force} = \frac{w}{g} a = \frac{w v^2}{g r}.$$

Let ω = Angular velocity of radius O P.

Then, $\qquad v = \omega r,$

$$\therefore \qquad F = \frac{w \omega^2 r^2}{g r} = \frac{w \omega^2 r}{g}. \quad . \quad . \quad . \quad . \quad (XIX)$$

This shows that the centrifugal force is proportional to the square of the angular velocity of the particle, and to its distance from the centre of rotation.

We may now show that a similar expression holds good for the case of an extended rigid body turning about an axis.

Taking any particle of the body of weight w, and at a distance x from the axis of rotation, we get :—

$$\textit{Cent. force of the element} = \frac{w \omega^2 x}{g}$$

$$\therefore \qquad \textit{Cent. force of whole body} = \frac{\omega^2}{g} \Sigma w x.$$

But, $\qquad \Sigma w x = W r.$

Where W = Weight of body,

And $\quad r$ = Distance of centre of gravity of body from axis of rotation.

$$\therefore \qquad F = \frac{W \omega^2 r}{g}. \quad . \quad . \quad . \quad . \quad . \quad (XX)$$

Hence, if the axis of rotation passes through the centre of gravity of the body, the centrifugal force is *nil*. If, however, the body be unsymmetrical about the axis of rotation, there may be, as explained in the next Lecture, a centrifugal *couple* tending to twist the axis of rotation and make the body rotate about some other axis.

EXAMPLE VIII.—A railway carriage weighing 4 tons is moving at the rate of 60 miles per hour round a curve $\frac{1}{4}$ mile in radius. Find the pressure on the rails due to centrifugal force; also, how much the outer rail should be higher than the inner rail in order that the pressure may be equally distributed on both? The distance between the rails is 4 feet $8\frac{1}{2}$ inches.

ANSWER.—Here, W = 4 × 2240 lbs.; $r = \frac{1}{4} \times 5280 = 1320$ feet; $v = \frac{60 \times 5280}{60 \times 60} = 88$ ft. per sec.

$$\therefore \left.\begin{array}{c}\text{Centrifugal}\\ \text{force}\end{array}\right\} = \frac{W v^2}{g r} = \frac{4 \times 2240 \times 88 \times 88}{32 \times 1320} = \mathbf{1642{\cdot}7 \text{ lbs.}}$$

Hence, if both the inner and the outer rails were on a level, the flanges of the wheels would press on the latter with a force of 1642·7 lbs. By raising the outer line of rails above the level of the inner one, the carriage may be made to lie on an incline, and the outer rails thus relieved of the centrifugal pressure.

Let h = Height of the outer rail above level of the inner rail.
" l = Distance between the rails = 4 ft. 8½ ins. = 56½ ins.
" F = Centrifugal force on carriage = 1642·7 lbs.

Then, as a question on the *Inclined Plane*, we get:—

$$F : W = h : l.$$

$$\therefore \qquad h = \frac{F}{W} \times l = \frac{1642{\cdot}7}{4 \times 2240} \times 56\tfrac{1}{2} = \mathbf{10{\cdot}4 \text{ inches nearly.}}$$

Straining Actions due to Centrifugal Forces.—Whenever a body rotates about an axis, the material of that body becomes strained by reason of the centrifugal forces set up. Thus, in the case of a flywheel or pulley, the centrifugal forces set up may be sufficient to tear the rim from the arms, the arms from the nave, or to burst the rim. In Lecture XVIII., Vol. I., we explained the effects of the centrifugal forces acting on a belt when moving over a pulley with a high velocity. We there showed that the tensions in the two parts of the belt were increased by the centrifugal action on that part of the belt which is in contact with the pulley. We shall now show that similar effects occur in a rapidly-revolving flywheel or pulley.

Suppose we have a flywheel built up of segments, each segment being attached to an arm, while they are also attached to each other by dowels and cotters, or bolts, &c. Let the weight of each segment be W; the distance of its centre of gravity from the axis of rotation, r, and the angular velocity of the wheel, ω. Then, neglecting the assistance afforded by the connection between the various segments, it is obvious that the tension in the arm to which the segment is attached is:—

$$P = \frac{W \omega^2 r}{g},$$

The arm must, therefore, be made strong enough to withstand this stress.

Again, in the case of a solid rim, the effect of the centrifugal

forces is to burst it along a section made by a plane containing the axis of the shaft. Let the figure represent the rim of a fly-wheel. Then, in order to calculate the stress in its material at any section, A B, made by a plane containing the axis, O, consider the effects of a thin slice of the rim at $a\,b$.

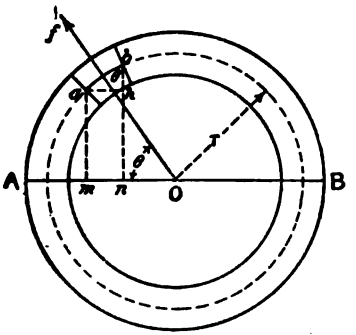

STRESS IN RIM OF FLYWHEEL DUE TO CENTRIFUGAL FORCE.

Let W = Total weight of rim.

" r = Mean radius of rim.

" x = Length of small arc $a\,b$ of mean rim.

" ω = Angular velocity of wheel.

$$\text{Then, } \frac{\textit{Weight of slice } a\,b}{\textit{Weight of rim}} = \frac{\textit{Arc } a\,b \textit{ of mean rim}}{\textit{Circumference of mean rim}} = \frac{x}{2\,\pi\,r}.$$

$$\therefore \quad \textit{Weight of element } a\,b = \frac{W}{2\,\pi\,r} \times x.$$

The centrifugal force of the element at $a\,b$ is :—

$$\therefore \qquad f = \frac{W}{2\,\pi\,r} \times \frac{\omega^2\,r}{g} \times x = \frac{W\,\omega^2}{2\,\pi\,g}\,x.$$

This force acts through the *c.g.* of the element. Resolve f in directions parallel and perpendicular to A B. The latter component only is effective in producing stress at the sections A and B.

$$\therefore \left.\begin{array}{r}\textit{Stress at sections A and B due}\\ \textit{to cent. force on element } a\,b\end{array}\right\} = f \sin\theta = \frac{W\,\omega^2}{2\,\pi\,g} \times x \sin\theta.$$

Where, $\theta = \angle \mathrm{A\,O}f.$

From a and b drop the perpendiculars $a\,m$, $b\,n$ on A B, and through a draw $a\,h$ perpendicular to $b\,n$. Then $\angle a\,b\,h = \theta$ and $x \sin\theta = a\,h = m\,n$.

$$\therefore \quad \left.\begin{array}{r}\textit{Stress at sections A and B due}\\ \textit{to cent. force on element } a\,b\end{array}\right\} = \frac{W\,\omega^2}{2\,\pi\,g} \times m\,n.$$

Continuing this reasoning for all the slices from A round to B, and adding the results, we get :—

$$\left.\begin{array}{l}\text{Total stress over}\\ \text{sections at A}\\ \text{and B}\end{array}\right\} = \frac{W\,\omega^2}{2\,\pi\,g}\,\Sigma\,m\,n = \frac{W\,\omega^2}{2\,\pi\,g}\times 2\,r = \frac{W\,\omega^2\,r}{\pi\,g}.$$

Let A = Area of section of rim at A, or B, in *square inches.*
" p = Stress in *lbs. per square inch* over section.
" w = Weight of *a cubic foot* of material of rim.

$$\text{Then,}\quad p = \frac{\textit{Total stress over section at A or B}}{\textit{Area of section}}.$$

$$\text{Or,}\quad p = \frac{\frac{1}{2}\times\dfrac{W\,\omega^2\,r}{\pi\,g}}{A} = \frac{W\,\omega^2\,r}{2\,\pi\,g\,A}.$$

But, W = *Area of cross section of rim in sq. ft.* $\times\ 2\,\pi\,r\,w.$

$$\therefore\quad W = \frac{A}{144}\times 2\,\pi\,r\,w.$$

Substituting this in the last equation, we get:—

$$p = \frac{w\,\omega^2\,r^2}{144\,g}\ .\ .\ .\ .\ .\ .\ \text{(XXI)}$$

Or, if n = Revolutions of wheel *per second,*
d = Diameter of rim *in feet,*
v = Velocity of rim *in feet per second* $= \omega\,r.$

$$\left.\begin{array}{ll}\text{Then,} & p = \dfrac{w\,\pi^2\,d^2\,n^2}{144\,g}\ \text{lbs. per square inch.}\\[2ex] \text{Or,} & p = \dfrac{w\,v^2}{144\,g}\quad\text{"}\quad\text{"}\quad\text{"}\end{array}\right\}\ \text{(XXII)}$$

From this we see that the stress per square inch does not depend on the cross area of the rim nor the diameter of the wheel, but only on the density of the material and its speed. It will also be observed that the centrifugal force in the rim is similar in effect to a hydrostatic pressure on the inside of a cylindrical vessel.

EXAMPLE IX.—A flywheel, 21 feet in diameter, makes 100 revolutions per minute. The weight of a cubic foot of its material is 448 lbs. Find the intensity of stress on a transverse section of rim, assuming that it is unaffected by the arms. If the safe stress permissible in the material is 6,000 lbs. per square inch, what is the greatest speed at which the wheel can be run with safety?

ANSWER.—Here, $w = 448$ lbs. per cubic foot; $d = 21$ feet; $n = \frac{100}{60} = \frac{5}{3}$ revolutions per second.

Therefore, from equation (XXII), we get:—

$$\text{Stress in rim} = p = \frac{w\,\pi^2 d^2 n^2}{144\,g}$$

Or,
$$p = \frac{448 \times \left(\frac{22}{7}\right)^2 \times 21^2 \times \left(\frac{5}{3}\right)^2}{144 \times 32} = 1176{\cdot}4 \text{ lbs. per sq. in.}$$

Next, let n = Maximum number of revolutions per second which the wheel can make without bursting.

Then, from the previous formula:—$p = \frac{w\,\pi^2 d^2 n^2}{144\,g}$,

We get, $n^2 = \frac{144\,g\,p}{w\,\pi^2 d^2}$, or, $n = \frac{12}{\pi d}\sqrt{\frac{g\,p}{w}}$.

Substituting $p = 6{,}000$, and the values for the other letters, we get:—

$$n = \frac{12}{\frac{22}{7} \times 21}\sqrt{\frac{32 \times 6000}{448}} = 3{\cdot}76 \text{ revs. per sec.} = 225{\cdot}6 \text{ per min.}$$

Note.—Students should refer to the author's *Text-Book on Steam and Steam Engines*, Lecture XVII., for a discussion of the effects of the inertia of the moving parts of an engine.

LECTURE XXII.—QUESTIONS.

1. Define the terms moment of inertia and radius of gyration of a body. Find the moment of inertia of rectangular lamina—first, with respect to one edge; secondly, with respect to a diagonal.

2. An axis is drawn through the centre of gravity of a body whose mass is M; a second axis is drawn parallel to the former and at a distance, h, from it. If I denotes the moment of inertia of the body with respect to the first axis, show that the moment of inertia with respect to the second axis is $I + Mh^2$. A fine wire of uniform thickness is bent into the form of a circle whose radius is r; find its moment of inertia with respect to an axis passing at right angles to the plane of the circle through a point in the circumference. (S. & A. Theor. Mechs. Adv. Exam., 1878.) *Ans.* $\frac{3}{2}Mr^2$.

3. State and prove the theorem of moments of inertia for parallel axes. Find the moment of inertia of a cylinder about a line perpendicular to its axis through its mid point. (S. & A. Theor. Mechs. Hons. Exam.)

4. A wheel and axle are composed of the same specific gravity. The wheel is 4 feet radius, and 6 inches thick. The axle is 6 inches radius and 4 feet long. Find radius of gyration of the whole about the axis. *Ans.* $k = \sqrt{7 \cdot 125} = 2 \cdot 67$ ft.

5. The rim of a flywheel is rectangular in section, 6 inches wide, outside and inside radii 6 and 5 feet respectively. The nave is cylindrical, 2 feet long and 1 foot in diameter. There are eight cylindrical spokes of 4 inches diameter. Find the radius of gyration of the wheel. *Ans.* 3·75 ft.

6. Show that the kinetic energy of a body revolving with an angular velocity, ω, about a given axis is $\frac{1}{2}I\omega^2$, where I denotes the moment of inertia of the body with reference to the axis. A flywheel has a mass of 30 tons, which may be supposed to be distributed along the circumference of a circle 8 feet in radius; it makes 20 revolutions a minute; find its kinetic energy in foot-pounds. (Adv. Theor. Mechs. Adv. Exam., 1883.) *Ans.* 295,000 ft.-lbs.

7. Find the moment of inertia of a rectangular lamina about an edge. A retangular lamina, whose shorter edges are 4 feet long, turns round one of its longer edges 50 times a minute. It weighs 441 lbs.; find its kinetic energy. (S. & A. Theor. Mechs. Adv. Exam., 1888.) *Ans.* 1008·3 ft.-lbs.

8. When a rigid body turns round an axis, what relation exists between its angular velocity and its kinetic energy? A rod of uniform density can turn freely round one end; it is let fall from a horizontal position; what is its angular velocity when it reaches its lowest position? Prove your equations. (S. & A. Theor. Mechs. Adv. Exam., 1878.) *Ans.* $\omega = \sqrt{\frac{3g}{l}}$.

9. How do you estimate the total energy possessed by a body when moving with both translation and rotation? Find the velocity of the centre (1) when a hoop, (2) when a disc, and (3) when a sphere rolls down an inclined plane of height, h. *Ans.* (1) $v = \sqrt{gh}$, (2) $v = 2\sqrt{\frac{gh}{3}}$, (3) $v = \sqrt{\frac{10gh}{7}}$.

10. Sketch, and explain the principle of the action of, a fly-press for stamping metals. If a velocity of 5 feet per second is given to the balls of such a press, and their motion is stopped after the screw has made one-quarter of a turn from the time that the die touches the metal, the pitch of the screw being $\frac{1}{4}$ inch; find the weight of the balls, so that the pressure exerted may be 4,000 lbs. *Ans.* 26·67 lbs. each.

11. Two weights of 100 lbs. each are placed at the ends of the arms of a fly-press, and are moving with a velocity of 12 feet per second. How many foot-pounds of work must be expended in bringing them to rest? Hence explain the mechanical action of the fly-press as a machine for punching or stamping metals. *Ans.* 450 ft. lbs.

12. In a fly-press there are two weights, each of 60 lbs., placed at the ends of an arm which drives the screw; and the velocity of each weight at the instant of striking the blow is 10 feet per second. The die at the end of the screw moves through $\frac{1}{10}$ inch in coming to rest; what mean statical pressure does it exert on the metal subjected to the operation of stamping? *Ans.* 22,500 lbs.

13. In a fly-press for stamping metals a ball of 70 lbs. is placed at each end of the lever attached to the head of the screw. At the moment of striking the blow the weights have a velocity of 550 feet per minute, and the die at the end of the screw indents the metal to a depth of $\frac{1}{12}$ inch before coming to rest. What would be the mean statical pressure exerted on the metal? (S. & A. Exam., 1893.) *Ans.* 26,468·75 lbs.

14. Prove that the kinetic energy of a train of railway carriages moving with velocity, v, is $\left\{W + w\left(1 + \frac{k^2}{r^2}\right)\right\}\frac{v^2}{2g}$ ft. lbs., where w denotes the weight of the wheels and axles; W the weight of the rest of the train; r the radius of the wheels, and k the radius of gyration of a pair of wheels about their axis, the units being feet, lbs., and seconds. Determine the acceleration with which the train would freely descend an incline of inclination, α.

15. Describe and show by the necessary sketches the construction of a fly-press for punching holes in iron plates. In such a press the two balls weigh 30 lbs. each, and are placed at a radius of 30 inches from the axis of the screw, the screw itself being of 1 inch pitch. What diameter of hole could be punched by such a press in a wrought-iron plate of $\frac{1}{4}$ inch in thickness; the shearing strength of the metal being 22·5 tons per square inch? (Consider that the balls are revolving at the rate of 60 revolutions per minute when the punch comes into contact with the metal, and that the resistance of the plate is overcome in the first sixteenth of an inch of the thickness of the plate.) (S. & A. Adv. Exam., 1896.) *Ans.* 1·12 ins.

16 A pendulum bob weighing 20 lbs. is suspended by a wire, the length from the point of suspension to the centre of the bob being 16 feet. The pendulum swings through an angle of 30° on each side of the vertical; find its potential energy when in the highest position, and its velocity when passing the lowest point. (S. & A. Adv. Exam., 1895.) *Ans.* 42·88 ft. lbs.; 1372·16 ft. per second.

17. A flywheel weighs 10,000 lbs., and is of such a size that the matter composing it may be treated as if concentrated on the circumference of a circle 12 feet in radius; what is its kinetic energy when moving at the rate of 15 revolutions a minute? How many turns would it make before coming to rest if the steam were cut off and it moved against a friction of 400 lbs. exerted on the circumference of an axle 1 foot in diameter? (S. & A. Theor. Mechs. Adv. Exam., 1886.) *Ans.* 55,520 ft.-lbs.; 44·2 turns.

18. The sectional area of the rim of a cast-iron flywheel is 12 square inches, and the mean radius (or radius of gyration) is 25 inches; what is the kinetic energy at 150 revolutions per minute? What moment of constant magnitude, and acting through one-quarter revolution, would increase the speed to 155 revolutions per minute at the end of the quarter revolution? What would be the length of a solid wrought-iron shaft, 5 inches in diameter, rotating at the same speed and having the same kinetic energy? (C. & G. Mech. Eng. Hons. Exam., 1884.) *Ans.* 35,707,000 ft.-lbs.

19. Prove the formula for the energy stored up in a flywheel on the supposition that the whole of the material is collected in a heavy rim of given mean radius. Apply the formula to show (1) the effect of doubling the number of revolutions per minute; (2) the effect of doubling the weight; (3) the effect of increasing the mean radius in the proportion of 3 to 2. (S. & A. Exam., 1890.)

20. The rim of a flywheel weighs 9 tons, and the mean linear velocity of its mass is assumed to be 40 feet per second; how many foot-tons of work are stored up in it? If it be required to store the additional work of 9 foot-tons, what should be the increase of velocity? *Ans.* 225 ft.-tons; 0·79 ft. per second.

21. A flywheel weighs 2½ tons, and its mean rim has a velocity of 40 feet per second. If the wheel gives out 10,000 foot-pounds of energy, how much is its velocity diminished? (S. & A. Exam., 1888.) *Ans.* 1·455 ft. per second.

22. A flywheel weighing 5 tons has a mean radius of gyration of 10 feet. The wheel is carried on a shaft of 12 inches diameter and is running at 65 revolutions per minute; how many revolutions will the wheel make before stopping if the coefficient of friction of the shaft in its bearing is 0·065? (Other resistances may be neglected.) (S. & A. Adv. Exam., 1896.) *Ans.* 354·66 turns.

23. A particle of given mass moves with a given velocity in a circle of given radius; state what is known as to the force which acts on the particle. Prove the statement. (S. & A. Adv. Theor. Mechs. Exam., 1896.)

24 If a locomotive weighing 55 tons runs round a curve of 1,200 feet radius at 20 miles per hour, what is its centrifugal force? How much higher in level should the outer rail be laid than the inner rail in order that the resolved part of the weight of the locomotive should balance this centrifugal force without pressure being exerted by the outer rail, the gauge being 4 feet 8½ inches? (C. & G. Mech. Eng. Hons. Exam., 1884.) *Ans.* 2760·6 lbs.; 1·27 inches.

25. Prove that a railway carriage running round a curve of radius, r, will upset if the velocity is greater than $\sqrt{\frac{g\,r\,a}{2\,h}}$, where a is the distance between the rails, and h the height of the centre of gravity of the carriage above the rails.

26. Show that by raising the outside rail of a railway track in going round a curve the tendency of the train to leave the rails is diminished, and that if θ be the inclination of the floor of the carriage to the horizontal, when there is no lateral pressure, $\tan\theta = \frac{v^2}{g\,r}$, where r is the radius of the curve, and v the velocity of the train. Hence show that on a 5-foot track, round a curve of one-eighth of a mile radius, that for a mean velocity of 30 miles an hour the outside rail ought to be raised 5½ inches above the level of the inside rail.

27. A body moves in a circle with a uniform velocity, show that it must be acted on by a constant force tending towards the centre, and find the magnitude of the force in terms of the radius of the circle, and of the mass and velocity of the body. A body weighing $2\frac{1}{2}$ lbs. fastened to one end of a thread 4 feet long is swung round in a circle of which the thread is the radius; what will be its velocity when the tension of the thread is a force of 20 lbs.? ($g = 32$). *Ans.* 32 ft. per second.

28. A segment of a flywheel with the arm to which it is attached weighs 3,500 lbs., and the mass of the portion may be taken as collected at a distance of 8 feet from the axis of the wheel, which makes 40 revolutions per minute. What is the force tending to pull away the segment and arm from the boss of the wheel? You are required to write out a proof of the formula which you employ. (S. & A. Hons. Exam., 1889.) *Ans.* 15,365 lbs.

29. Show that the stress per square inch on the rim of a flywheel is equal to the momentum of the amount of rim (per square inch of section) which passes a fixed point in the unit of time. Find the limiting speed of periphery, the material being such that a bar of uniform section 900 feet long may be supported by tension. (S. & A. Mach. Const. Hons. Exam., 1885.) *Ans.* $30\sqrt{gr}$.

30. A flywheel 20 feet in diameter makes 80 revolutions per minute. Find the stress in its rim due to centrifugal forces, assuming that it is unaffected by the connection with the arms. The weight of a cubic foot of the material forming the rim is 500 lbs. What is the maximum speed at which the wheel can be safely run if the tensile strength of the material has not to exceed 6,000 lbs. per square inch? *Ans.* 762 lbs. per sq. in.; 224·5 revs. per min.

31. When the fly-wheel of a certain traction engine lessens in speed from 150 to 140 revolutions per minute, there is a loss of kinetic energy (on the motion of the whole engine as well as the fly-wheel) of 25,000 foot-pounds.

If the speed is 160 revolutions per minute, how far will the engine travel up an ascent of 1 in 100 before coming to rest, if engine and truck together weigh 30 tons, and there is a constant frictional resistance on a level road of 20 lbs. to the ton? (S. & A. Adv. Exam 1897.)

32. The centre of gravity of a body of 100 lbs. is revolving at 15 ins. from an axis, at 250 revolutions per minute. What is its centrifugal force? Prove the Rule. (S. & A. Adv. Exam., 1897.)

LECTURE XXIII.

CONTENTS. — Governing of Engines — Watt's Governor — Action of Watt's Governor—Theory of Watt's Governor—Conical Pendulum—Example I.—Common Pendulum Governor—Crossed-Arm Governor—Parabolic Governors—Galloway's Parabolic Governor—Porter's loaded Governor—Theory of Porter's Governor—Example II.—Spring loaded Governors—Proell's and Hartnell's Spring Governors—Macfarlane's Safety Governor—Willans' Spring Governor—Pickering Governor—Governing by Throttling and Variable Expansion—Shaft Governors—Relays—Knowles' Supplemental Governor—Inertia Governors—Flywheels—Balancing Machinery—Weston Self-balancing Centrifugal Machine—Questions.

Governing of Engines.*—For many purposes to which engines are applied, it is necessary that they should maintain a uniform speed. Owing to variations of load and of pressure on the piston, they must have some regulating device, in order to accomplish this object. Fluctuations of the speed of a steam engine are of two kinds. (1) Those which occur during the time of a revolution, and are *periodic*, being caused by the varying pressure on the piston, and obliquity of the connecting rod. (2) Those which are due to change of load, or boiler pressure, and are *not periodic*. To control the first of these as far as possible, an engine is fitted with a **Flywheel**, and for the second a **Governor** is also required.

* The following is a list of books and papers treating of governors and governing:—

Paper on "The Electrical Regulation of the Speed of Steam Engines," by P. W. Willans. *Proc. Inst. C.E.*, 1885, vol. lxxxi., p. 166.

Paper on "A New Method of Investigation applied to the Action of Steam Engine Governors," by Prof. Dwelshauvers-Dery of Liége, translated by Michael Longridge. *Proc. Inst. C.E.*, 1888, vol. xciv., p. 210.

Paper on "The Cyclical Velocity-Variations of Steam and other Engines," by H. B. Ransom. *Proc. Inst. C.E.*, 1889, vol. xcviii., p. 357.

Paper on "The Application of Governors and Flywheels to Steam Engines," by Prof. Dwelshauvers-Dery, translated by Bryan Donkin. *Proc. Inst. C.E.*, 1891, vol. civ., p 196.

Paper on "Flywheels and Governors," by H. B. Ransom. *Proc. Inst. C.E.*, 1892, vol. cix., p. 330.

Paper on "Steam Engine Governors and their Insufficient Regulating Action with Extreme Variations of Load," by Prof. Dwelshauvers-Dery, translated by Bryan Donkin. *Proc. Inst. C.E.*, 1892, vol. cx., p. 276.

Paper on "A Method of Testing Engine Governors," by H. B. Ransom. *Proc. Inst. C.E.*, 1893, vol. cxiii., p. 194.

A governor is a piece of mechanism which regulates the amount of steam supplied to the engine, to suit the work it is doing, whereas, as explained in the previous Lecture, a fly-wheel acts in virtue of its inertia, so as to distribute throughout a whole revolution the energy developed in the cylinder. The governor can have no effect whatever on the periodic variations of speed, since it can only act during the time that steam is being admitted to the cylinder. With regard to the irregular fluctuations of speed, due to a change of load, the flywheel makes them more gradual and thus gives the governor time to act. A great many varieties of governors have been invented since the introduction of the steam engine, such as hydraulic, centrifugal, inertia, and electrical governors. By far the greatest number, however, depend for their action on centrifugal force and inertia, and since these form useful examples of the practical application of the principles enunciated in the previous Lectures, we shall now confine our remarks to such governors.

Watt's Governor.—One of Watt's important inventions was his conical pendulum governor, as applied to his double-acting engine.* This governor consists of two arms, A A, carrying heavy balls, B B, and pivoted on a pin, P, passing through the centre of the vertical spindle, V S. The upper ends of these arms are bent, as shown on the figure, and are connected by short links, L L, to the sleeve, S. This sleeve is free to move vertically on the spindle, V S, but is made to rotate with it by a feather, F, and corresponding keyway. This sleeve acts on one end of the bell crank, B C, and thus moves the rod con-

Paper on "The Mechanical and Electrical Regulation of Steam Engines," by John Richardson. *Proc Inst. C.E.*, 1895, vol. cxx., p. 211.

Paper on "Governing of Steam Engines by Throttling and by Variable Expansion," by Capt. H. R. Sankey. *Proc. Inst. M.E.*, 1895, p. 154.

Paper on "Steam-Engine Governors," read before the Manchester Association of Engineers, by C. F. Budenberg, M.Sc. See *The Practical Engineer*, 17th April, 1891, vol. v., p. 258.

A series of articles on "Engine Governors," by R. G. Blaine, M.E., in *The Practical Engineer*, beginning 13th June, 1890, vol. iv., p. 386, and ending 24th April, 1891, vol. v., p. 277.

Article on "A New Shaft Governor," by E. J. Armstrong, in *The Practical Engineer*, 28th July, 1895, vol. xii., p. 71.

Article on "Shaft Governors," by E. T. Adams, in the *Electrical World* of New York. July, 1896.

See Index for Governors in *Gas, Oil, and Air Engines*, by Bryan Donkin, published by Charles Griffin & Co.

The Steam Engine, by D. K. Clark (Blackie & Son), chap. v., on Governors, p. 65, half-vol. iii.

* See the Author's *Text-Book on Steam and Steam Engines*, Lecture II., for a description of Watt's engines. Also Lecture XIX., Volume I., of this book for an illustration of same.

nected to the throttle valve of the engine. The vertical spindle may be driven by the engine by means of a belt or rope passing round a pulley keyed on it, or by bevel wheels, as shown at BW. In order to relieve the pin, P, the arms are driven by the guides, G G, which are fixed to the vertical spindle.

Action of Watt's Governor.—The governor is so adjusted, that when the engine is working at its normal speed, the balls rotate

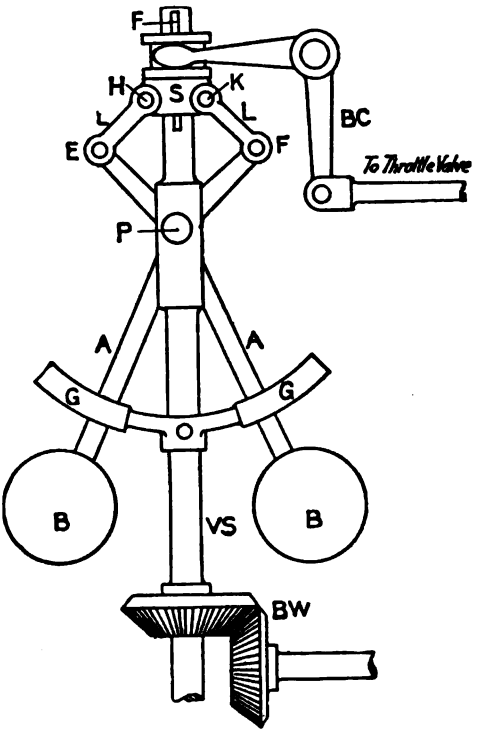

WATT'S PENDULUM GOVERNOR.

at a certain distance from the vertical spindle, and thus the throttle valve is kept sufficiently open to maintain that speed. Should the load be *decreased*, the speed of the engine, and therefore that of the governor balls, naturally becomes greater. This causes an increase of the centrifugal force of the balls, and therefore they diverge further, thereby pulling down the sleeve,

and partially closing the throttle valve, which diminishes the supply of steam and the power developed by the engine. On the other hand, should the load be *increased* the reverse action takes place, the balls come closer together, the sleeve is raised, the throttle valve opened wider, and more steam admitted to the engine. It will thus be seen that a change of speed must take place before the governor begins to act; further, that for any permanent change in the work to be done, there is a permanent alteration of speed. For each particular load on the engine, the throttle valve will be opened by a definite amount, which will be different for different loads, and each position of the valve has a corresponding position of the governor balls. But, as will be shown further on, each position of the balls corresponds to a definite speed, so that there will be a particular speed for each different load.

Theory of Watt's Governor—Conical Pendulum.—Let the balls

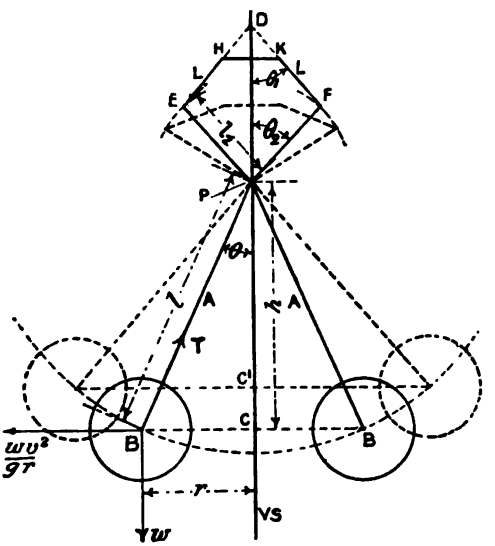

THEORY OF WATT'S GOVERNOR.

be rotating about the vertical spindle with a uniform velocity. Then the several forces acting on the different parts of the instrument are in equilibrium with each other. The arms, A, will describe the surface of a cone, B P B, whose height is P C, and for a given velocity of the balls there will be a definite

height of this cone. It will be sufficient to consider one ball and arm, since what is true for one will be true for the other.

Let w = Weight of one ball in lbs.
" v = Velocity of balls in *feet per second.*
" h = Height, P C, of cone in *feet.*
" l = Slant height, P B, of cone in *feet.*
" r = Radius, B C, of base of cone in *feet.*
" T = Tension in one arm, A.

There are three forces acting on the ball, B, viz.:—

(1) The weight, w, of the ball acting vertically downward.

(2) The centrifugal force, $w v^2 \div g r$, acting in its plane of rotation, and in the direction C B.

(3) The tension in the arm, A, acting in the direction B P.

These three forces keep the ball in equilibrium, and can, therefore, be represented, in magnitude and direction, by the three sides of a triangle taken in order. If we draw a triangle, having its sides parallel or perpendicular to the directions of these forces, the lengths of the sides of this triangle will be proportional to the forces respectively. Now, such a triangle exists in the figure itself—viz., the triangle P C B—the sides of which are parallel to the three forces:—

Hence, $$h : r = w : \frac{w v^2}{g r} = 1 : \frac{v^2}{g r}.$$

$$\therefore \qquad h = \frac{g r^2}{v^2}, \text{ and } \frac{r}{v} = \sqrt{\frac{h}{g}}.$$

If t = time in *seconds* of one complete revolution of balls,
n = number of revolutions per *second,*

Then, $$t v = 2 \pi r, \text{ and } n = \frac{1}{t}.$$

Substituting these in the previous equation we get the following important formulæ:—

$$= 2 \pi \frac{r}{v} = 2 \pi \sqrt{\frac{h}{g}} \quad . \quad . \quad . \quad . \quad . \quad . \qquad \text{(I)}$$

That is, *the period of rotation is proportional to the square root of the height of the cone.*

Also, $$n = \frac{1}{t} = \frac{1}{2 \pi} \sqrt{\frac{g}{h}} \quad . \quad . \quad . \quad . \quad . \quad . \quad . \qquad \text{(II)}$$

Or, if N be the number of revolutions per *minute* = 60 n,

Then, $$N = \frac{30}{\pi}\sqrt{\frac{g}{h}}. \quad . \quad . \quad . \quad . \quad . \quad . \quad . \quad . \quad . \quad (II_a)$$

That is, *the number of revolutions, or the speed of the engine or governor, varies inversely as the square root of the height of the cone.*

Equation (II_a) may be written in this useful form :—

$$h = \frac{30^2 g}{\pi^2} \times \frac{1}{N^2} = \frac{2936}{N^2} \text{ feet.} \quad . \quad . \quad (II_b)$$

Or, *the height of the cone depends only on the speed of rotation, and varies inversely as the square of the number of revolutions.*

Let the speed of the governor be altered from N_1 to N_2 revolutions per minute, then the heights of the cone corresponding to these speeds are :—

$$h_1 = \frac{2936}{N_1^2}, \text{ and } h_2 = \frac{2936}{N_2^2}.$$

Therefore, for a change of speed from N_1 to N_2 revolutions per minute the height of the cone will be altered by the amount :—

$$h_1 \sim h_2 = 2936\left(\frac{1}{N_1^2} \sim \frac{1}{N_2^2}\right) = \frac{2936\,(N_2^2 \sim N_1^2)}{N_1^2\,N_2^2}. \quad (III)$$

If, however, the height of the governor be kept constant, and equal to $h = \frac{900\,g}{\pi^2 N_1^2}$, the centrifugal force will change from $\frac{w v_1^2}{g r}$ to $\frac{w v_2^2}{g r}$, or from $\frac{w r \pi^2 N_1^2}{900\,g}$ to $\frac{w r \pi^2 N_2^2}{900\,g}$, and the difference will produce a tension, or a thrust, in the links L L. If T_2 be the tension, or thrust, in one link L; l, l_1, l_2 the lengths of B P, E D, P E; and θ, θ_1, θ_2 their inclinations to the vertical, then by taking moments about P, we have :—

$$T_2 \times l_2 \cos(\theta_1 + \theta_2 - 90) = \frac{w r \pi^2}{900\,g}(N_2^2 \sim N_1^2) \times h,$$

Or, $$T_2 = \frac{w r \pi^2 (N_2^2 \sim N_1^2)\,h}{900\,l_2\,g \sin(\theta_1 + \theta_2)}.$$

Now, the vertical force acting on the sleeve, which is available for overcoming friction, and may be called the *working effort* for that change of speed, is the vertical components of

the stresses in the two links L L. These two stresses are equal.

$$\therefore \textit{ The working effort } = 2\,T_2 \cos \theta_1$$

$$\text{,, ,, } = \frac{w\,r\,\pi^2\,h\,(N_2^2 \sim N_1^2)}{450\,l_2\,g} \times \frac{\cos\theta_1}{\sin(\theta_1 + \theta_2)}$$

$$\text{,, ,, } = \frac{w\,r\,\pi^2\,\frac{900\,g}{\pi^2 N_1^2}\,(N_2^2 \sim N_1^2)\cos\theta_1}{450\,l_2\,g\,\sin(\theta_1 + \theta_2)}$$

$$\text{,, ,, } = \frac{2\,w\,r\cos\theta_1\,(N_2^2 \sim N_1^2)}{l_2\,\sin(\theta_1 + \theta_2)\,N_1^2} \quad . \quad . \quad . \quad . \quad . \quad (IV)$$

It is usual for P E and E H to be made equal in length, and then $\theta_1 = \theta_2$ nearly, unless H K be great. In that case :—

$$\textit{The working effort} = \frac{2\,w\,r\cos\theta_2\,(N_2^2 \sim N_1^2)}{l_2\,\sin 2\,\theta_2\,N_1^2}$$

$$\left.\begin{aligned} \therefore \quad \text{,, ,, } &= \frac{w\,r\,(N_2^2 \sim N_1^2)}{l_2\,\sin\theta_2\,N_1^2} \\ \text{Or, } \quad \text{,, ,, } &= \frac{w\,l\,\sin\theta\,(N_2^2 \sim N_1^2)}{l_2\,\sin\theta_2\,N_1^2} \end{aligned}\right\} \quad . \quad . \quad . \quad . \quad (IV_a)$$

If, further, $\theta = \theta_2$, which will always be the case when the sleeve is attached to the arm below the point of suspension, as in the next form of governor, then:—

$$\textit{The working effort} = \frac{w\,l\,(N_2^2 \sim N_1^2)}{l_2\,N_1^2} \quad . \quad . \quad . \quad . \quad . \quad . \quad . \quad . \quad (IV_b)$$

It should be noted, however, that this is the effort exerted by the governor when it is just starting to move. The working effort becomes smaller and smaller as the balls rise, until, when the balls have attained the position corresponding to the new speed, it is *nil*.

The movement of the sleeve, corresponding to an alteration in the height of the cone, is best determined graphically by drawing the centre lines of the arms and links to scale for different positions of the balls.

EXAMPLE I.—Find the rise of the balls of a pendulum governor, when its speed is increased from 60 to 62 revolutions per minute. Find also the height of the cone of revolution at the lower speed, and the working effort, if the balls weigh

22 lbs. each, and each arm is jointed to the link at two-thirds of its length below its point of suspension.

Here, $N_1 = 60$, $N_2 = 62$, rise of balls $= h_1 - h_2$, $w = 22$, and $\frac{l}{l_2} = \frac{3}{2}$.

Therefore, from equation (III) we get:—

$$h_1 - h_2 = 2936\left(\frac{N_2^2 - N_1^2}{N_1^2 \times N_2^2}\right) = 2936\left(\frac{62^2 - 60^2}{60^2 \times 62^2}\right).$$

$$\therefore \qquad h_1 - h_2 = \cdot 0518 \text{ foot or } \cdot 62 \text{ inch.}$$

Also from equation (II_b):—

$$h_1 = \frac{2936}{N_1^2} = \frac{2936}{3600}.$$

$$\therefore \qquad h_1 = \cdot 816 \text{ foot} = 9 \cdot 79 \text{ inches.}$$

And from equation (IV_b):—

$$\textit{The working effort} = \frac{w\,l\,(N_2^2 \sim N_1^2)}{l_2\,N_1^2}$$

$$\text{,, ,,} \quad = \frac{22 \times 3\,(62^2 - 60^2)}{2 \times 60^2}$$

$$\text{,, ,,} \quad = 2 \cdot 237 \text{ lbs.}$$

In this case, as we assume $l_1 = l_2$ and $\theta_1 = \theta_2$, the travel of the sleeve will be twice the rise of the point where the link joins the arm, and this will be two-thirds of the alteration in height.

$$\therefore \textit{Travel of sleeve} = 2 \times \frac{2}{3}(h_1 - h_2) = \frac{4}{3} \times \cdot 62 = \cdot 827 \text{ inch.}$$

Common Pendulum Governor.—A common modification of Watt's governor is shown by the following figure. Here, the arms A A, carrying the balls B B, instead of being jointed together by a pin passing through the vertical spindle V S, are pivoted at M and N to a cross-piece, C P, which is rigidly connected to the spindle. The links L L, carrying the sleeve S, are attached to the arms at the points E and F.

The formulæ deduced for Watt's pendulum governor are equally applicable to this case. The only thing requiring special attention here, is the height of the cone of revolution. The vertex of the cone is always at the point where the centre lines of the arms meet. In this case, the arms terminate at M and N, which are at a short distance from V S, and thus the vertex of the cone will be a variable point on the centre line of

the vertical spindle. When the balls are in the position shown by the full lines, the vertex is at P, and the height of the cone is P C; but, when the balls move into the new position, shown by dotted lines, the vertex of the cone is at P′, and the height of the cone is P′ C′.

The effect of suspending the arms at a short distance from the vertical spindle, is to cause the movement of the sleeve to be less for a given variation in the height of the governor, than would be the case were the centres of suspension in the vertical spindle. It will be apparent from the figure, that the effective variation of height is C C′ = (P C − P′ C′) − P P′ = (h_1 − h_2) − P P′, instead of h_1 − h_2, as in the previous case. Hence,

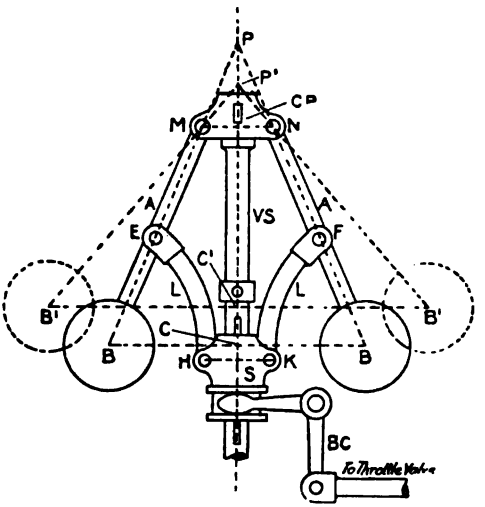

COMMON PENDULUM GOVERNOR.

this governor is *less sensitive* than the former, since the speed must vary between greater limits for a given movement of the sleeve. The *sensitiveness* of a governor depends on the movement given to the sleeve for a given variation in speed, and also on the smallness of the time taken by the governor in adapting itself to its new position. In order, therefore, to increase the sensitiveness of this form of governor it is necessary that the points M and N should be as near the vertical spindle as possible.

Crossed-Arm Governor. — The special feature in which this governor differs from the former ones is, that the arms are

suspended from pins placed on the opposite sides of the spindle to that of their balls. From an inspection of the figure, it will be apparent that crossing the arms in this manner causes a greater movement of the sleeve for a given variation in the height than in the pendulum governor. The rise of the balls in this case is :—

$$C C' = P C - P' C' + P P' = (h_1 - h_2) + P P'.$$

The sensitiveness of this governor is therefore much greater than either of the two previous forms. By properly propor-

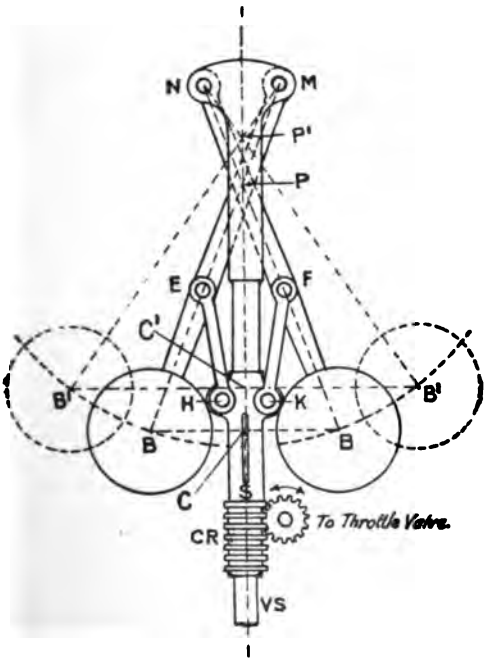

CROSSED-ARM GOVERNOR.

tioning the lengths of the arms and N M, so that the balls move out and in, along a curve which is approximately a parabola, this governor may be made almost isochronous. and, therefore, extremely sensitive.* It will be noticed that the sleeve of the

* A governor is said to be *isochronous* when its speed of rotation (and, therefore, the height of the cone) is the same for all positions of the balls within its range.

governor shown, has a circular rack C R, which gears with a pinion on the throttle valve spindle.

Parabolic Governors.*—Governors have been so constructed that their balls were guided to move in a truly parabolic path, and thus be absolutely isochronous, but owing to their complication they have not come into general use. With any centrifugal governor, the speed must increase somewhat before the extra centrifugal force is able to overcome the friction resisting the motion of the links, sleeve, valve, &c., and if it be absolutely isochronous, whenever the friction is overcome the balls would rise right up to the top of their range, and remain there until the speed has fallen sufficiently for gravity to reassert itself and overcome the friction, which would now tend to keep the balls up. They would then come down to the bottom of their range, and there would thus be continual hunting. Such a governor would therefore be wanting in stability or steadiness.

LOADED PARABOLIC GOVERNOR, BY GALLOWAYS, LD.

Galloway's Parabolic Governor.—From the illustration it will be seen, that in this type two cylindrical rollers take the place of the ordinary balls in the previously mentioned governors. These rollers are suspended at each end by links from a crosshead fixed to the top of the governor spindle, and naturally rise and fall in circular arcs with these links as radii. They move along parabolic slots cut in a weight W, which rotates with the spindle, but is free to rise and fall along the same. By this arrangement, the moment of the centrifugal force of the rollers is balanced by that of the weight at nearly the same speed for all positions. Hence, this governor may be considered practically insochronous. To the bottom of the slotted weight there is sometimes attached a sleeve termi-

* See the Appendix to *The Steam Engine*, by Prof. Rankine (Chas. Griffin & Co.), and Chapter XV. of *Practical Treatise on the Steam Engine*, by Arthur Rigg (E. & F. Spon), for descriptions of guided parabolic governors.

nating in a collar, which engages the forked lever connected to the throttle valve, or expansion gear; but in this case, a central spindle C S, which is carried up inside the main governor spindle, rises and falls with the weight W, and acts directly on an equilibrium valve. The governor is driven through gearing contained in the cast-iron box seen at the foot of the vertical column.

Porter's Loaded Governor.—From equation (IV) and Example I. we see that the simple pendulum governors possess a comparatively small working effort, unless the balls are very heavy. To overcome this objection Porter made the balls smaller, and loaded the sleeve with a heavy weight. This increases the height of the cone, corresponding to any particular speed, and all the forces concerned, and thus gives a greater working effort. It can be used both in connection with throttle valves and some forms of expansion gear. To minimise the oscillations of the ordinary Porter governor, Messrs. Clayton & Shuttleworth have made a cylindrical hole in the top of the central weight, and fixed a piston on the vertical spindle, thus forming a simple air cushion.

PORTER LOADED GOVERNOR, BY TANGYES, LIMITED.

Theory of the Porter Governor.—Each of the balls is in equilibrium under the action of four forces acting in a plane passing through the axis of rotation. These forces are:—(1) the weight of the ball w, (2) the centrifugal force $w v^2 \div g r$, and (3) the tensions in the two links, T_1 and T_2. Let A B C D A be a polygon representing these forces, A B being parallel and equal to T_1, B C to w, C D to T_2, and D A to the centrifugal force. If B C be produced to meet A D in E, then C E is equal to the vertical component of T_2, and must therefore be equal to half the load W, since this weight is supported by the vertical components of the tensions in the two bottom links.

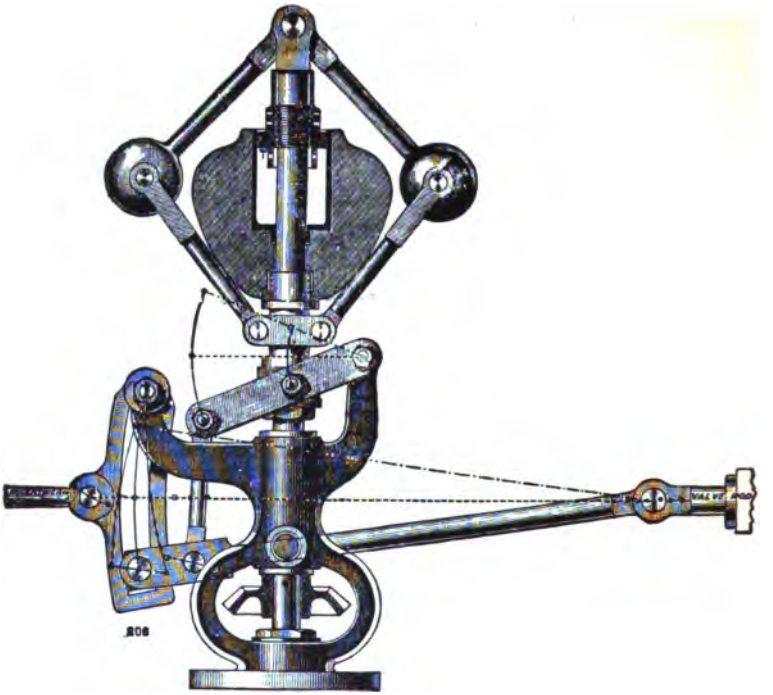

PORTER GOVERNOR, BY CLAYTON & SHUTTLEWORTH.

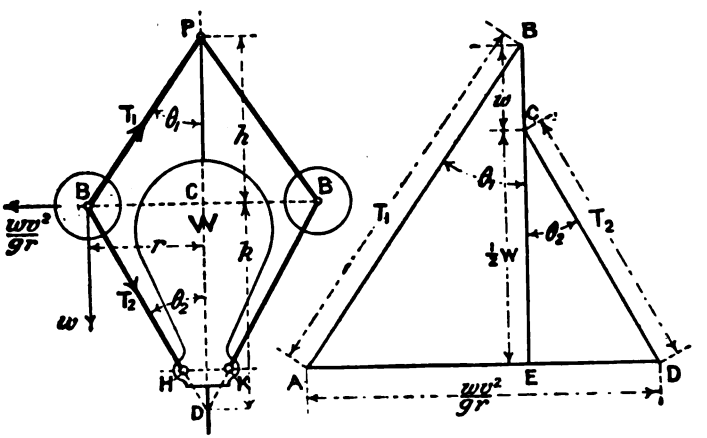

ACTION OF THE PORTER GOVERNOR.

If the inclination of the links B P, B H to the vertical, be θ_1 and θ_2 respectively, and the heights C P, C D be denoted by h and k, then, the other letters being the same as before, we have :—

$$T_1 \sin \theta_1 + T_2 \sin \theta_2 = \frac{w v^2}{g r}.$$

$$T_1 \cos \theta_1 = w + \tfrac{1}{2} W, \text{ or } T_1 = \frac{w + \frac{1}{2} W}{\cos \theta_1}.$$

And, $$T_2 \cos \theta_2 = \tfrac{1}{2} W, \quad \text{or } T_2 = \frac{\frac{1}{2} W}{\cos \theta_2}.$$

$$\therefore \frac{w + \frac{1}{2} W}{\cos \theta_1} \sin \theta_1 + \frac{\frac{1}{2} W}{\cos \theta_2} \sin \theta_2 = \frac{w v^2}{g r}.$$

But, $$\tan \theta_1 = \frac{r}{h}; \quad \tan \theta_2 = \frac{r}{k}; \text{ and } v = 2 \pi r n.$$

$$\therefore \quad (w + \tfrac{1}{2} W) \frac{r}{h} + \tfrac{1}{2} W \frac{r}{k} = \frac{w \times 4 \pi^2 r^2 n^2}{g r}.$$

Or, $$(w + \tfrac{1}{2} W) \frac{1}{h} = \frac{w \times 4 \pi^2 n^2}{g} - \frac{\frac{1}{2} W}{k}.$$

$$\therefore \quad h = \frac{w + \frac{1}{2} W}{\frac{4 \pi^2 n^2 w}{g} - \frac{\frac{1}{2} W}{k}}.$$

Hence, $$h = \frac{(2 w + W) g k}{8 \pi^2 n^2 w k - W g}$$

Or, since $n = \frac{N}{60}$, $$h = \frac{450 (2 w + W) g k}{\pi^2 N^2 w k - 450 W g} \quad \text{(V)}$$

This governor is usually constructed with all four links of equal length; then $k = h$, and $\theta_1 = \theta_2 = \theta$, very nearly, unless the distance H K is great, and in our further investigations we shall assume that this is so.

In this case we have :—

$$T_1 \sin \theta + T_2 \sin \theta = \frac{w v^2}{g r}.$$

$$T_1 \cos \theta = w + \tfrac{1}{2} W, \text{ or } T_1 = \frac{(w + \frac{1}{2} W)}{\cos \theta},$$

And, $$T_2 \cos\theta = \tfrac{1}{2} W, \qquad \text{or } T_2 = \frac{\tfrac{1}{2} W}{\cos\theta}$$

$$\therefore \qquad (w + \tfrac{1}{2} W) \tan\theta + \tfrac{1}{2} W \tan\theta = \frac{w v^2}{g r}.$$

But, $\tan\theta = \dfrac{r}{h}$ and $v = 2\pi r n$.

Hence, $$(w + W)\frac{r}{h} = \frac{w \times 4\pi^2 r^2 n^2}{g r}.$$

$$\left.\begin{aligned} \therefore \qquad h &= \frac{w + W}{w} \times \frac{g}{4\pi^2 n^2} \\ \text{Or,} \qquad h &= \frac{w + W}{w} \times \frac{900 g}{\pi^2 N^2} = \frac{w + W}{w} \times \frac{2936}{N^2} \end{aligned}\right\} \text{(VI)}$$

We might also have arrived at this result by putting h for k in equation (V).

If the speed of rotation change from N_1 to N_2 revolutions per minute, the corresponding heights of the governor will be:—

$$h_1 = \frac{w + W}{w} \times \frac{900 g}{\pi^2 N_1^2}; \qquad \text{and } h_2 = \frac{w + W}{w} \times \frac{900 g}{\pi^2 N_2^2}.$$

The alteration in the height of the cone of revolution would therefore be:—

$$\left.\begin{aligned} h_1 \sim h_2 &= \frac{w + W}{w} \times \frac{900 g}{\pi^2} \times \left(\frac{N_2^2 \sim N_1^2}{N_1^2 N_2^2}\right) \\ \text{Or, } h_1 \sim h_2 &= 2936 \frac{w + W}{w}\left(\frac{N_2^2 \sim N_1^2}{N_1^2 N_2^2}\right) \end{aligned}\right\} \quad . \quad . \quad . \quad \text{(VII)}$$

With the arrangement of links usually adopted in this governor, the travel of the sleeve is twice the change in the height of the balls and equal to $2\,(h_1 \sim h_2)$.

Using the simpler equation (VI) we see that:—

$$W = \frac{\pi^2 N^2 w h}{900 g} - w.$$

And, therefore, if the speed alter from N_1 to N_2 revolutions per minute, the load necessary to keep the height of the cone constant, and equal to h, $\left(= \dfrac{w + W}{w} \times \dfrac{900 g}{\pi^2 N_1^2}\right)$, will change from—

$$W = \frac{\pi^2 N_1^2 w h}{900 g} - w \text{ to } W' = \frac{\pi^2 N^2 w h}{900 g} - w.$$

But if the actual load be W, the difference $W' \sim W$ is available for overcoming friction and moving the valve. This may be called the *working effort* for that change in speed, and is equal to:—

$$W' \sim W = \frac{\pi^2 w h}{900 g}(N_2^2 \sim N_1^2)$$

$$\text{Or,} \quad W' \sim W = \frac{\pi^2 w \dfrac{w + W}{w} \times \dfrac{900 g}{\pi^2 N_1^2}(N_2^2 \sim N_1^2)}{900 g}$$

$$\therefore \quad W' \sim W = (w + W)\frac{N_2^2 \sim N_1^2}{N_1^2}. \quad . \quad . \quad . \quad . \quad . \quad . \quad \text{(VIII)}$$

Example II.—The balls of a Porter governor weigh 4 lbs. each, and the central weight 36 lbs. If all the links are of equal length, find the height of the governor when revolving 240 times per minute. If the speed increase to 248 revolutions per minute what will be the working effort and the rise of the balls and the sleeve?

Here, $N_1 = 240$; $N_2 = 248$; $w = 4$; and $W = 36$.

From equation (VI), $\quad h_1 = \dfrac{w + W}{w} \times \dfrac{2936}{N_1^2}$,

Or, $\quad h_1 = \dfrac{4 + 36}{4} \times \dfrac{2936}{240 \times 240}$.

$\therefore \quad h_1 = \cdot 51$ foot or $6 \cdot 12$ inches.

From equation (VIII), *The working effort*, $\quad = (w + W)\dfrac{N_2^2 - N_1^2}{N_1^2}$,

" " $\quad = (4 + 36)\dfrac{248^2 - 240^2}{240^2}$,

" " $\quad = 2 \cdot 71$ lbs.

And from equation (VII), $\quad h_1 - h_2 = 2936\dfrac{w + W}{w}\left(\dfrac{N_2^2 - N_1^2}{N_1^2 N_2^2}\right)$,

Or, $\quad h_1 - h_2 = 2936 \times \dfrac{4 + 36}{4} \times \dfrac{248^2 - 240^2}{240^2 \times 248^2}$

$\therefore \quad h_1 - h_2 = \cdot 0324$ foot or $\cdot 389$ inch.

$\therefore \quad$ *Travel of sleeve* $= 2(h_1 - h_2) = 2 \times \cdot 389$,

" $\quad = \cdot 778$ inch.

On comparing these results with those of Example I., it will be noticed that while both governors weigh about the same, the loaded governor has a working effort of about 20 per cent. greater than that of the Watt governor, but its travel and height are less. It will also be seen from equations (III) and (VII), by putting $N_2 = cN_1$, where c is a constant, that the change in height corresponding to a given percentage variation in speed gets smaller as the speed increases.

Spring Loaded Governors.—Soon after the introduction of the Porter governor, Mr. John Richardson, of Messrs. Robey & Co., Lincoln, designed one in 1869, in which a spring was substituted for the weight. This improvement produces a greater working effort with less weight, bulk, and cost. A spring has less inertia, and acts much more quickly than a weight, and it has also a certain amount of cushioning action. A governor loaded with a spring can act in any position, whereas one with a weight must work vertically. The equations for a spring governor may be obtained in the same way as for the weighted governor, but the load W will be different for different positions of the balls, owing to the varying compression of the spring.

Proell and Hartnell's Spring Governors.*—The first of the two following figures illustrates the well-known Proell spring governor. It will be observed that a helical spring, contained in a cylindrical case, surrounds the governor spindle, and bears upon the inner ends of the two bell crank levers, which are connected to the arms carrying the governor balls. The dotted lines show the positions of the balls for a speed above the normal. As they move out to this position the spring is compressed and the sleeve is raised. It will further be noticed that the links are so proportioned that the balls diverge in nearly a straight line. Consequently, when working vertically, the balls do not move either with or against gravity.

It will be observed that there are no less than three pin joints on each side of the Proell governor above the sleeve, at each of which there must be friction. In Hartnell's governor, illustrated by the next figure, there is but one.†

Here, the governor balls are fixed directly to the outer ends of the bell crank levers, the inner ends of which bear upon a collar on the upper end of the movable tube or sleeve, M S.

* The figure of Proell's governor is from *The Proc. Inst. C.E.*, vol. cxx., Session 1895-96, by kind permission of the Council, from a paper read by John Richardson, M.Inst.C.E., on "The Mechanical and Electrical Regulation of Steam Engines," which the student should consult.

† See Lecture XVIII. of the Author's *Text-Book on Steam and Steam Engines* for a description of an engine to which this governor is applied.

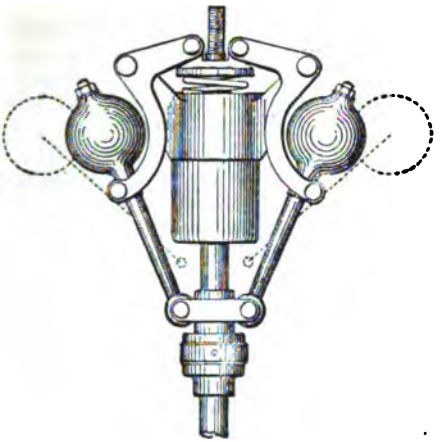

PROELL'S SPRING GOVERNOR.

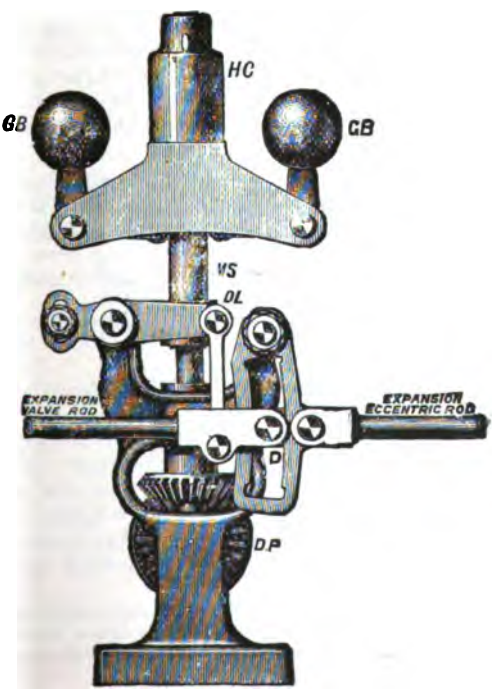

HARTNELL'S SPRING GOVERNOR, BY MARSHALL, SONS & CO., LTD.

Between the top of this collar and the upper end of the hollow casting H C, which is keyed to the top of the governor spindle, there is placed a strong helical spring. The lower end of M S has a double collar engaged by a forked lever, which works another lever connected to the drag link D L, actuating the expansion valve rod. In the discussion on Mr. Richardson's paper already referred to, Mr. Kuhne states that a Proell governor, weighing about 2 cwts., developed a working effort of 21 lbs. for an increase of 2 per cent. in the speed, and that a Porter governor to do the same would weigh $\frac{3}{4}$ ton. Also, that the force required to compress the spring when the balls were quite open was 1,781 lbs.

Macfarlane's Safety Governor.—This governor is fitted inside the steam passage, and acts directly on the grating throttle valve C. There are two weights D, working on centres at E, which move the sliding piece F, attached to the throttle valve spindle G. This spindle is forced to the right by the spring H, placed inside the governor spindle I, and is pulled to the left as the balls fly out. The governor spindle passes through the stuffing box T, and is driven by the pulley X. In addition to the throttle valve there is a stop valve K, and seat O; and the bearing L for the throttle valve forms part of this. From the left of the two small figures it will be seen that the holes in C and L are opposite to each other when the engine is working



NORMAL POSITION OF THROTTLE VALVE.



CLOSED POSITION OF THROTTLE VALVE IF BELT BREAKS.

normally, but should the speed increase, C is pulled to the left and cuts off towards that side. Should the belt which drives the governor slip or break, or the governor stop from any cause, the throttle valve is forced to the right by the spring and shuts off steam completely, as shown on the other figure. The stop valve is shown closed in the large figure.

Willans' Spring Governor.*—In the previous cases, the pressure of the spring has to be transmitted through the pin joints of the

* For a description of Willans' central-valve triple expansion engine, to which this governor is fitted, see Appendix III. of the Eleventh Edition of the Author's *Text-Book on Steam and the Steam Engine.*

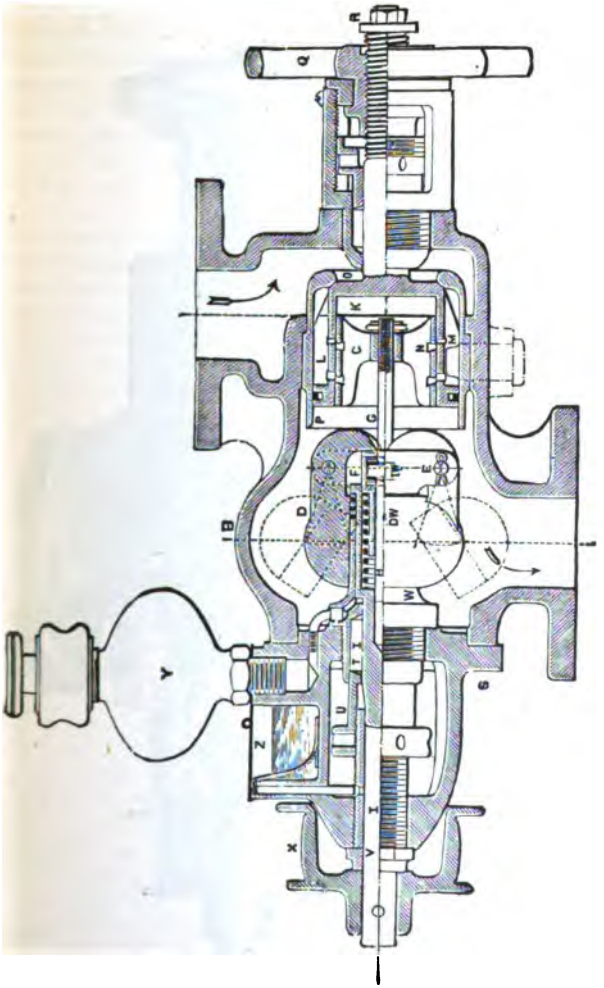

SECTION OF MACFARLANE'S SAFETY GOVERNOR.

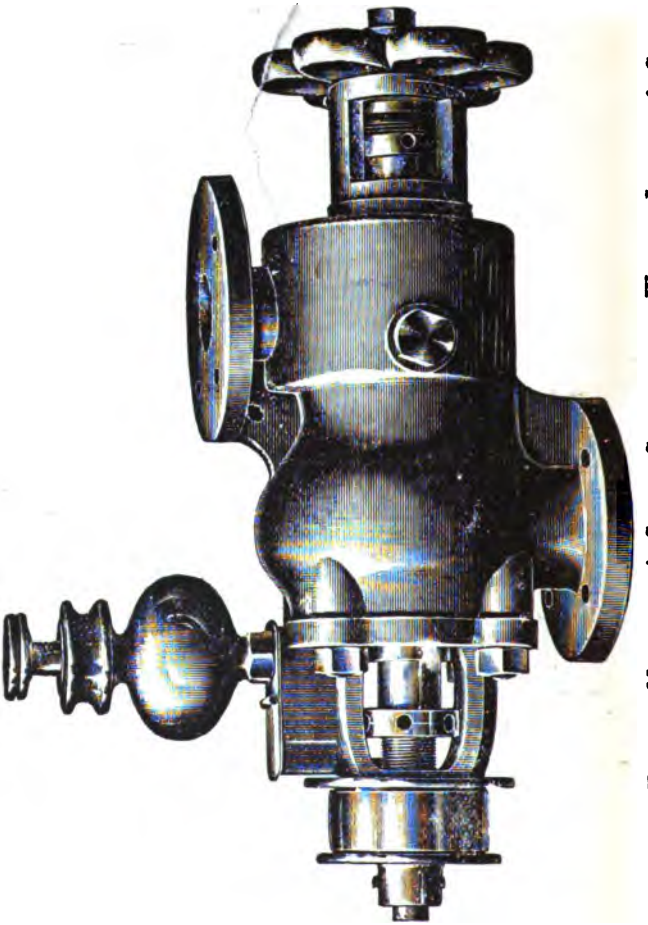

Outside View of Macfarlane's Safety Governor, by Watson, Laidlaw & Co.

governor arms, and thereby causes more friction and wear and tear than would be the case if the springs were directly connected to the balls. In Willans' governor, as will be seen from the figure, the balls are connected directly by a helical spring A, on each side of the governor spindle. Another spring F, is clamped at its upper end to the throttle-valve spindle G, and hooked at its lower end to the bracket carrying the bell crank lever E. This spring pulls the valve rod downwards, in opposition to the springs A, and thus pushes the sleeve against the toes N N (shown dotted), of the governor arms. By adjusting the tension in F, by the nut M, the governor can be set to the required speed while the engine is running. It will be noticed that this governor works horizontally, and is driven directly by one end of the shaft.

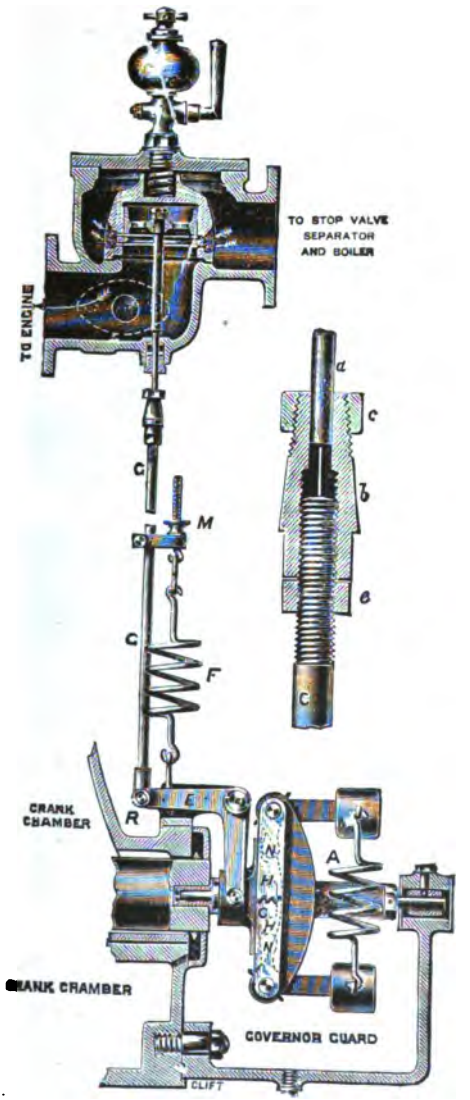

WILLANS' SPRING LOADED GOVERNOR.

Pickering Governor.—A very simple and direct acting governor which has been introduced for small electric light engines is shown by the next figure. Here the balls are supported by flat springs, which act directly on the throttle-valve spindle. There is also an auxiliary spring, as seen just

PICKERING GOVERNOR, BY TANGYES, LTD.

below the driving spindle, actuated by a thumb screw and worm wheel, which enables the attendant to adjust the speed of the engine whilst running.

Governing by Throttling and Variable Expansion.—Prior to 1876, governors generally controlled steam engines by actuating a butterfly throttle valve of the form shown in the figure. This valve, although simple in construction, is difficult to fit so as to remain steam tight, and hence the double-beat valve as in the next illustration, or still better, a grating piston valve like that shown attached to the Willans' governor, has been adopted in preference. The ordinary butterfly throttle valve is not, as at one time supposed, a balanced valve, since the action of a fluid rushing past an oblique plane, is such as to cause a greater

pressure on the forward edge and thus tend to close the valve. A good throttle valve should be able to entirely stop the admission of steam to the cylinder.

Recently, many patents have been taken out for controlling the speed of an engine by altering the point of cut-off. In most cases, this enables the engine to work more economically;

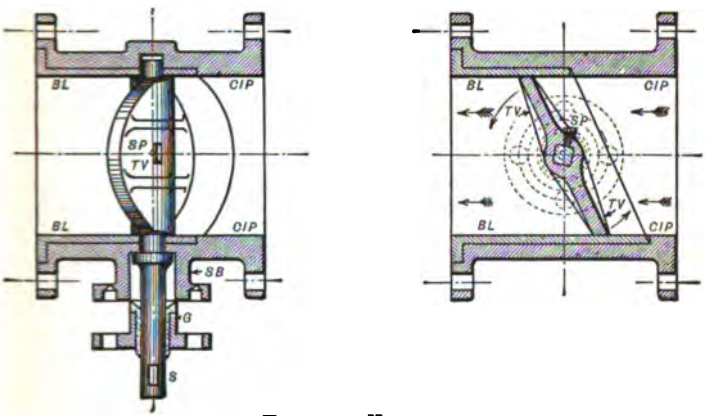

THROTTLE VALVE.

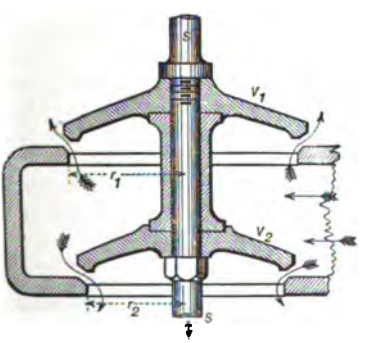

DOUBLE-BEAT VALVE.

but as shown by Captain Sankey in his paper on "Governing of Steam Engines by Throttling and by Variable Expansion," read before the Institute of Mechanical Engineers, in April, 1895, the indicator diagrams obtained from engines governed by this method are often "cloaks for exaggerated initial con-

densation," and it may be found that the actual feed water used, is less with ordinary throttling than with variable expansion. Throttling the steam varies the amount supplied by varying the pressure, while the volume used remains constant. On the other hand, automatic expansion supplies the steam at a constant pressure but alters the volume used per stroke.

The point of cut-off may be controlled either by means of a separate expansion valve, or by acting directly on the main valve or valves. In the first case, there are two eccentrics which work the main and the expansion valves. As will be seen from the illustrations of the Hartnell, and Clayton & Shuttleworth's governors, the stroke of the expansion valve is altered by a drag link and a block connected to the governor sleeve. In the second case, when a slide valve is used, either the throw or the position of the main eccentric is varied by a shaft governor, and no second eccentric is required. With "trip gear" the governor automatically releases the admission valves sooner or later, according to the load on the engine.*

Shaft Governors.—A large number of these have been designed, but the following illustrations will serve to show their general principle and action. A circular casting is keyed to the crank shaft, and carries on one side a pair of symmetrically arranged weights jointed thereto at one end, but whose other ends are free to move in a plane perpendicular to the shaft against the resistance of the interposed helical springs. On the other side of this casting there is fixed a pair of straps embracing a circular disc carrying the eccentric which works the valve. The centre of this disc is some distance from the centre of the shaft and that of the eccentric. The governor weights have bosses which pass through slots in the circular casting, and are connected by links to studs on the disc. In moving outwards by centrifugal force, these weights compress the springs and rotate the disc, thus changing the position of the eccentric, and varying the cut-off of the slide valve.

Relays.†—Except in the case of "trip gear," the effort required to work the throttle valve, or expansion gear, may be considerable, and can only be satisfactorily supplied by a relay—that is, by making the engine itself, or steam from the boiler, or water pressure, or electro-magnetic mechanism, move the valve, while

* See Lecture XVIII. of the Author's *Text-Book on Steam and Steam Engines* for illustrations.

† See *Engineering*, 1st January, 1886, p. 4, for a description of Lüdes steam relay governor. Also "Regulation of Steam Engines," by John Richardson, *Proc. Inst. C.E.*, vol. cxx., 1895, Part II., for description and discussion on electrical and other relays for governors.



FRONT VIEW.

BACK VIEW.

AUTOMATIC EXPANSION SHAFT GOVERNOR,
BY MESSRS. RANSOMS, SIMS & JEFFERIES, LD.



SHAFT GOVERNOR APPLIED TO A HIGH-SPEED ELECTRIC LIGHT ENGINE.

the governor has simply to control the relay. In most relays that have been used for governing, the governor starts the relay, and then the latter goes on without any control, until the position of the governor is altered, and it is set into motion in the opposite direction. All such relays necessarily have the fault of hunting, but this is not so for one of the steering-gear type. The governor, as it were, informs such a relay when to move and how far, and the extent of the change in the height of the governor cone determines the travel of the relay.

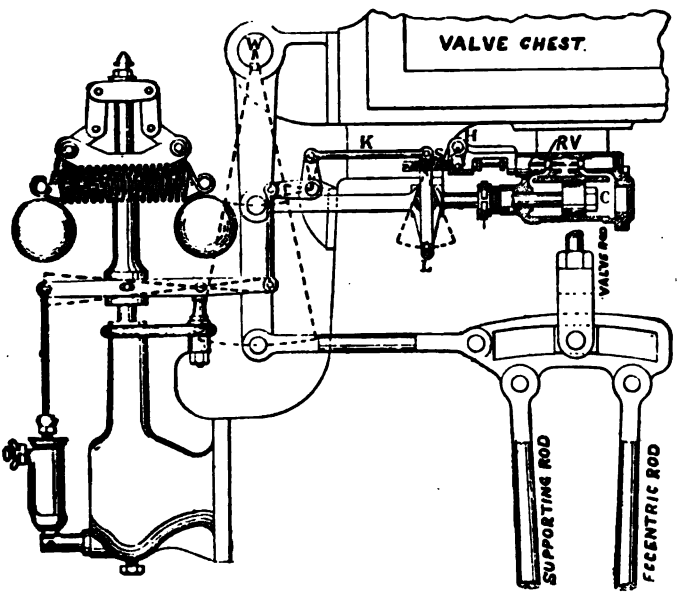

GOVERNOR WITH RELAY FOR COMPOUND AND TRIPLE EXPANSION ENGINES, BY DAVEY, PAXMAN & CO.

The steam relay shown is applied by Messrs. Davey, Paxman & Co. to compound and triple expansion engines. The weigh-shaft W, which works the expansion gears of all the cylinders, is connected with the piston of the small relay cylinder C. The relay valve R V, which admits steam to this cylinder, is worked by the floating lever L, and allows steam to enter at its middle and exhaust at its ends. The lower end of the floating lever is attached at L, to the crosshead of the relay piston rod, and its upper end through the links K, &c., to the governor sleeve,

while the small piston valve of the relay is connected to an intermediate point. It will thus be seen that when the governor balls rise, R V will move to the left, and so admit steam to the left of the relay piston. This forces the piston inwards, and pushes the eccentric-rod end of the drag link further from the block attached to the engine valve rod, and therefore reduces the travel of the valve and the power of the engine. In addition, as the relay piston moves one way or the other, it rotates the floating lever L, about its upper end, and brings R V back to its mid position, and so automatically comes to rest. By this means, the relay piston and main slide valves are made to follow all the motions of the governor, and the amount of the motion of the relay piston will depend on the change in the height of the balls. The governor itself has very little work to do, since it has only to move the small valve R V. By means of the weigh shaft W, and levers attached to it the valve rods of all the cylinders are moved simultaneously, in the same way as the one shown. Minor adjustments of the speed may be made while the engine is running by altering the tension in the spring S, by means of a worm and worm wheel on the end of the spindle H.

Knowles' Supplemental Governor.*—Another method is that invented by Knowles. Here two governors are used, a large one to control the valve in the ordinary way, and a smaller one to alter the length of the rod connecting the first one to the valve. This is effected by fitting two friction cones to the sleeve of the smaller, or supplemental, governor, and having a third between them, which will gear with one or other if the governor rises or falls by more than a prescribed amount. The valve rod is in two parts, having a right- and left-handed screw respectively at their adjacent ends, and the nut which joins these screws is rotated by the third friction cone. This governor has been extensively employed in spinning mills, where the fluctuations in load are neither great nor sudden, but where the speed must remain very constant.

Inertia Governors.†—For small gas engines, which always receive a full charge of gas during each cycle or none at all, a form of governor known as the inertia governor, has been found suitable. In the one first illustrated, the gas valve is opened by a valve opener V O, which is actuated through the lever L, by the cam C, fixed on the side shaft S. On the lower end of the valve opener there is a bell crank B C, engaging a slot on the

* See the *Practical Engineer*, vol. v., p. 205, March 27, 1891.

† See *Gas, Oil, and Air Engines*, by Bryan Donkin, for other forms of gas engine governors.

governor weight W. This weight is supported by a spring fixed to a bracket on the lever L. As the lever is moved upwards, the inertia of the weight W, causes it to lag behind, and thus compress the spring, but the latter is so adjusted that as long as the speed does not exceed the normal, B C is not moved down sufficiently to cause V O to miss the gas valve spindle.

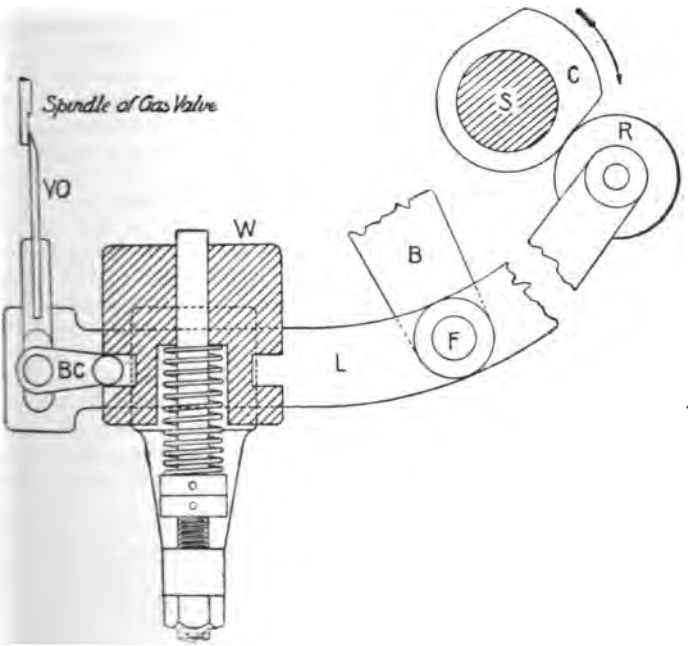

INERTIA GOVERNOR FOR STOCKPORT GAS ENGINE.

INDEX TO PARTS.

C for Cam.	B for Bracket.
S ,, Side shaft.	W ,, Inertia weight.
R ,, Roller.	B C ,, Bell crank.
L ,, Lever.	V O ,, Valve opener.
F ,, Fulcrum.	

If, however, the speed should rise above the normal, the inertia of the weight is sufficient to press B C down far enough to cause V O to pass to the right of the spindle, and then no gas is admitted for that cycle. As the direction of the thrust necessary to open the valve passes through the centre of the pin supporting

the bell crank B C, it is received direct from the lever L, and does not affect the governor weight W.

Another, and simpler form of inertia governor, as used in small Otto gas engines, depends for its action on the inertia of a small weight W, and adjusting weight A W. The vibrating arm V A, is driven by the link L, from a pin on the end of the side shaft S S, and causes the valve opener V O, and the weight W, to move backwards and forwards. The centre of gravity of the weights and valve opener being to the right of the pin P, the point of V O is pressed against the flat of the gas valve spindle. The effect of the inertia of these weights acts below P, and therefore tends to turn V O downwards when P is moved to the left. The position of A W is so regulated by the adjusting nuts A N, that when the speed exceeds what is desired, the latter tendency will predominate and cause the end of V O to pass below the valve spindle and leave the valve unopened.

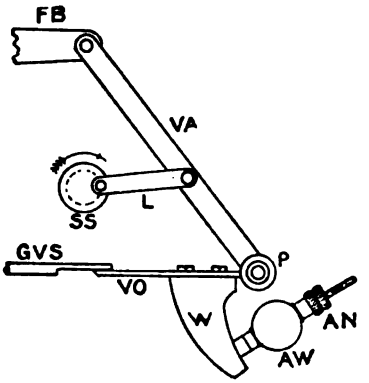

INERTIA GOVERNOR FOR OTTO GAS ENGINE.

Flywheels.—We have already mentioned that the function of the flywheel is to take up and give out energy so as to minimise the fluctuations in speed due to the periodic changes in the crank effort, and also to reduce the suddenness of other changes in the speed of the engine.

In the previous Lecture we found an expression for the tension per square inch in the rim of a flywheel due to centrifugal force, and saw that it was independent of the cross area of the rim. The highest speed at which a flywheel can be run with safety, will therefore depend upon the tensile strength and the density of the material of which it is made, for it is evident that we cannot make it able to go faster by enlarging the cross area of the rim, since that increases the total stress in exactly the same proportion as it increases the total strength. Consequently, for very high speeds it is necessary to select a material, and so dispose of it, as to have the greatest possible strength for a given mass. Hitherto, flywheels have usually been made of cast iron, either moulded and cast in one piece, or built up in several segments; but recently,

they have been made of wrought iron or steel, so as to offer a much greater resistance to bursting, either by the method suggested by Prof. Sharp,* or by winding steel wire into an annular trough made of steel plates at a definite distance from the crank shaft.

Balancing Machinery.†—If a flywheel be not accurately balanced, it will cause wobbling stresses, which produce vibration and wear, and which become greater as the speed is increased. Owing to the recent demand for high-speed machinery, such as sugar-drying, cream separating, hydro-extracting, and electric light machinery, the attention of engineers has been specially directed of late to the necessity for more perfect balancing, with a view to reducing vibration and its attendant noise, tear, and wear. Even in the case of express trains, it has been found advisable to balance the carriage wheels. This is done by placing their axles and their wheels on a framing with springs of exactly the same kind as those to be used on the carriage for which they are intended, and running them at their highest speed of, say, 60 to 70 miles per hour. Pieces of clay are placed upon the inside of their rims until they run perfectly smoothly. These lumps are then replaced by pieces of cast iron or lead of the same weight, and the process repeated until as perfect a balance as possible has been obtained.

In works where the importance of balancing machinery is recognised, the machine to be balanced is placed upon a testing table and run at gradually increasing speeds. At each speed the balance is made as perfect as possible, by trial, in a manner similar to that just described for railway carriage wheels, until the maximum working speed has been reached, and the whole is capable of running practically free from vibration even when not secured by bolts or clamps.

A common method of balancing pulleys in the workshop is to mount them on a shaft, or mandril, which is then placed on two parallel and perfectly level straight edges. This is a delicate method of procuring a *statical* balance, but it does not follow that there is a true *dynamic* balance, as there may be a *centrifugal couple*, which will cause vibration, and needless pressure on the bearings. To take a simple case, con-

* See Prof. Sharp's pamphlet on "A New System of Wheel Construction" (Technical Publishing Co., Manchester), and a paper on "Flywheels," by John Galt, C.E., M.E., *Proc. Canadian Electrical Assoc.*, Montreal, 1894.

†See *Proc. Inst. Eng. and Shipbuilders in Scotland*, January, 1891, for a paper on "Centrifugal Action in Practical Work," by John Laidlaw. Also, *Proc. N.E. Coast Inst. of Eng. and Shipbuilders*, vol. xii., 1896, for a paper on "An Investigation into the Force tending to produce Vibration in High-Speed Engines," by J. M. Allan.

sider a crank shaft with two cranks 180° apart. The static balance may be perfect if the cranks are similar; yet, it is clear that the centrifugal forces of the two cranks, although equal, parallel, and opposite in direction, are not in the same straight line, and therefore form a couple in a plane passing through the axis of the shaft. The plane of this couple revolves with the cranks, and it consequently tends to make the axis describe a double cone in space, the common vertex of this cone being at the centre of gravity of the whole rotating mass. Similarly, with a pulley there may be an excess of material on one side at one extremity of a diameter, and at the other extremity an excess on the other side, which, while the static balance is perfect, cause a centrifugal couple, and set up objectionable vibrations at a high speed. The final adjustment of the balance of a wheel or pulley should therefore always be made at the highest speed at which it is intended to run. In order to have a *statical* balance about an axis, it is sufficient that the axis should pass through the centre of gravity of the *whole* mass, but for a perfect *dynamic* balance, it must *also* pass through the centre of gravity of *every* section taken at right angles to the axis. It is possible, however, in some cases to have the body as a whole balanced without this last condition, but in such cases there will be several centrifugal couples whose resultant is zero, but which tend to bend the shaft at several places.

Weston Centrifugal Machine. — As a useful application of centrifugal force, and an example of a self-balancing high-speed machine, we here illustrate the Weston centrifugal for drying sugar. The first figure gives a general view of a pair of 30-inch centrifugals suspended from the house framing, with sugar-breaker, pug mill, swivel shoot, and molasses gutter. The baskets of these machines are driven at 1,200 revolutions per minute, and give an output of 12 to 16 tons of dried raw sugar, or 12 to 20 tons of dried refined sugar, per day of ten hours, and require about seven horse-power to drive them.

In order to charge the machine, the valve at the bottom of the pug mill is opened, so as to allow the sugar to gravitate down the scoop into the basket B, seen in the vertical section. When a sufficient charge has been given, the pug mill valve is closed, and the basket started rotating by a friction pulley of the kind shown in Lecture VIII., p. 136 of Vol. I. The belt which drives the pulley P, connected to the spindle S, thus gradually brings the speed up to its normal. The centrifugal force causes the water and molasses to pass through the numerous holes in the periphery of the basket into the monitor case M C, from whence it escapes by the discharge pipe D P; while



WESTON CENTRIFUGAL SUGAR-DRIERS, BY WATSON, LAIDLAW & CO.

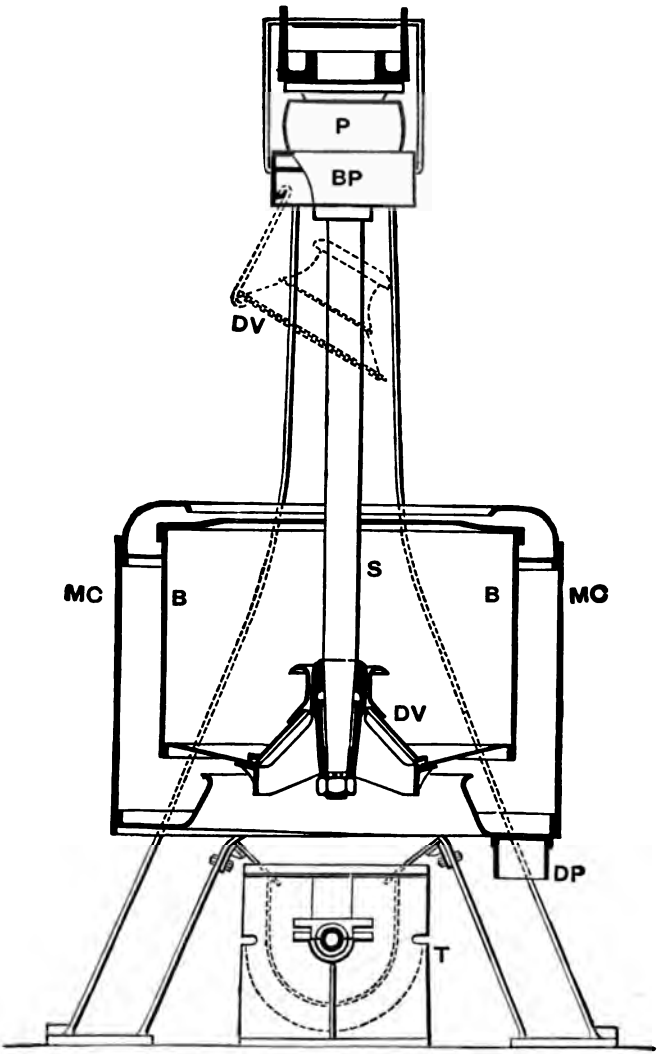

VERTICAL SECTION OF WESTON CENTRIFUGAL.

the sugar forms a wall around the inside of the basket. When the sugar is dried, the friction grip of the driving pulley is relieved, and the brake-strap applied to the brake pulley B P, so as to bring the basket and its contents quickly to rest. The conical cover, or discharge valve D V, is then raised and hung on the brake pulley, as seen in dotted lines. The wall of sugar is broken down and swept through the central opening into the conveying trough T. It is then forced along this trough by a large screw to wherever it may be wanted.

The basket is not compelled to revolve about a fixed axis, but is permitted to choose its own centre of rotation by the use of elastic bearings. By allowing the revolving basket to oscillate within certain limits, it assumes as its centre of gyration the centre of gravity of the basket and its contents, and so becomes self-balancing. This reduces to a minimum the power required to drive the machine, severe stresses, wear and tear, and the vibrations transmitted to the building. By referring to the sectional view of the spindle, it will be easily understood how this is accomplished. A strong block B, is bolted to the overhead beam, and inside this block are placed two india-rubber buffers I I, the upper of which sustains the suspended spindle S, by a nut and washer. This spindle does not rotate, but it carries, at its lower end, a series of washers which support the bearing F, fixed to the outer revolving spindle. The pulley P, and brake pulley B P, are attached to the upper end of this outer spindle, and the perforated basket to its lower end. The hollow portion of this spindle is filled with oil, so that the bearing F runs in an oil bath, and is always well lubricated.

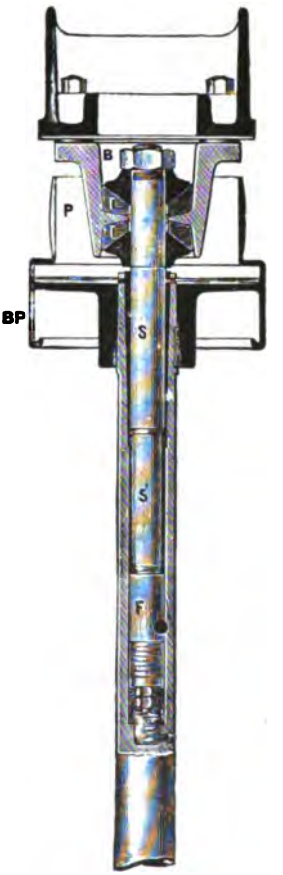

SECTION OF SPINDLE AND BEARINGS FOR WESTON CENTRIFUGAL.

There are many other applications of this principle, such as in hydro-extractors, cream-separators, &c. The next illustration shows a modification of the above machine adapted for extracting oil from engine waste, turnings, screws, &c., or drying crystals and ores. The material to be dried is put into the hollow pan A, which is then rotated at about 2,000 revolutions per minute. The oil, or water, escapes through the narrow opening between the upper and lower parts of the pan at B, into the outer casing D, and thence to the spout E. The pan is emptied by lifting it



UNDER-DRIVEN CENTRIFUGAL EXTRACTOR, BY WATSON, LAIDLAW & CO.

bodily from the top of the spindle and turning it upside down. It rests on a leather-faced disc on the top of the spindle, and is kept central by a continuation of the same, which fits easily into a recess in the bottom of the pan. This arrangement permits of a little slip at starting, by which the driving belt is relieved from any sudden or severe stress. The spindle is similar in construction to the one just described, but inverted, so that this machine is also self-balancing.

LECTURE XXIII.—QUESTIONS.

1. The governor and flywheel of an engine have both the purpose of regulating its speed. Explain how their actions in this respect differ.

2. Explain the principle of *Watt's* pendulum governor, and state its advantages and defects. Various methods have been proposed for improving this form of governor; discuss the action of any such modern apparatus with which you are acquainted.

3. What are the principal essentials of a good steam engine governor? Sketch, in outline, any one form of governor with which you are acquainted, and explain to what extent it is satisfactory according to the conditions which you have laid down, or how it might be improved.

4. Sketch the ordinary pendulum or ball governor of a steam engine. Mark on your drawing some particular line whose length is related to the number of revolutions of the balls. State the relation as nearly as you know it. If the line referred to be shortened in proportion of 2 : 3. how much would the number of revolutions be increased? *Ans.* $\sqrt{3} : \sqrt{2}$.

5. Sketch an ordinary Watt's governor, and explain its action upon the valve with which it is connected. Why is it an improvement to shift the points of suspension so that the arms cross each other?

6. Explain the advantages of the crossed-arm governor for a steam-engine. Find the height of the cone when the engine is making 40 revolutions per minute, and prove the formula on which you rely. (S. and A. Adv. Steam Exam., 1891.)

7. Define the term "isochronous" as applied to governors. How may isochronism be approximately obtained? Prove the formula, connecting the height of the cone of revolution and the number of revolutions per minute, for a simple pendulum governor. (S. and A. Adv. Steam Exam., 1892.)

8. Sketch the pendulum governor as Watt made it. From the balls of a common governor, whose collective weight is A, there is hung by a pair of links (of lengths equal to the ball-rods) a load, B, capable of sliding up and down the spindle. Compare the loaded and common governor as regards sensitiveness, the weights of the arms or links being neglected. (S. and A. Adv. Steam Exam.)

9. Find an expression for the height of the cone in a loaded governor when rotating at a given number of revolutions per minute. Show, by a sketch, the connection of the governor with a throttle valve. By what arrangement may the tendency to over-sensitiveness be corrected? (S. and A. Hons. Steam Exam., 1891.)

10. Find the height of a simple or "Watt" governor revolving at 80 revolutions per minute. If the same governor had a weight of 40 lbs. attached to the sleeve, the balls weighing 3 lbs. each, what should be its height, supposing the same speed to be maintained, and the link work to be such that the sleeve rises twice as fast as the balls? Neglect the weight of the connecting links. (S. and A. Adv. Steam Exam., 1895.)

11. Find the height of a simple conical pendulum revolving at 80 revolutions per minute. If a loaded governor, making 240 revolutions per minute, had a weight of 20 lbs. attached to the sleeve, the balls weighing 2 lbs. each, what would be its height, the vertical motion of the balls being half that of the sleeve? (S. and A. Adv. Steam Exam., 1894.)

12. Sketch and describe any spring loaded governor, and compare the action of the spring with that of a weight.

13. What objection is there to regulating the speed of an engine by the throttle valve?

14. Explain what is meant by automatic expansion gear, showing wherein lie its special advantages in the economic working of an engine. Sketch such an arrangement and its connections. (S. and A. Hons. Steam Exam., 1894.)

15. Explain by the aid of the necessary sketches the construction of either the Armington-Sims or the Westinghouse high-speed flywheel governor and valve gear. Show clearly how in these arrangements the throw and angle of advance of the eccentric are varied, whilst the lead is kept constant. (S. and A. Hons. Steam Exam., 1895.) (Robey's and Ransoms, Sims & Jefferies' shaft governors are similar to those asked for.)

16. What special benefit is obtained by adding a relay to a governor? Sketch and describe a relay which automatically follows up the motion of the governor.

17. Sketch Knowles' supplemental governor and describe its action.

18. Describe the pendulum governor of the Otto engine, and point out, by reference to sketches, the manner in which it acts. (S. and A. Adv. Steam Exam., 1889.)

19. Explain clearly the arrangement by which the speed of an Otto engine is regulated (S. and A. Adv. Steam Exam., 1891.)

20. Describe any form of inertia governor used for regulating the speed of a gas engine.

21. Describe, with proper sketches, a form of vibrating pendulum regulator as fitted to an Otto gas engine, and explain how it acts, and is made adjustable. Assuming that the pendulum is actuated by the rotation of the gas and air valve, describe the mechanism connecting the end of the valve with the pendulum, showing that it forms a well-known combination in linkwork. (S. and A. Hons. Steam Exam., 1894.)

22. Explain why it is necessary to balance high-speed machinery, and describe the most approved method of doing so.

23. What primary law in mechanics asserts itself when some revolving piece of machinery moves at a high velocity, and is unbalanced? A weight of 1 lb. is placed on the rim of a wheel 2 feet in diameter, which revolves upon its axis and is otherwise balanced. The linear velocity of the rim being 30 feet per second, what is the pull on the axis as caused by the weight of 1 lb.? *Ans.* 28·1 lbs.

24. Explain by sketches and description how railway carriage wheels for express trains and their axles are balanced. Give your reasons for and against the common workshop expression that a perfect statical balance is not one when the machine is run at a high speed.

PART IV.—GRAPHIC STATICS.

LECTURE XXIV.

CONTENTS.—Graphic Statics—A Framed Structure—Classification of Frames—Firm Frames—Deficient Frames—Redundant Frames—Conditions of Equilibrium—Bow's Method of Lettering—Solution of a Triangular Frame—Reciprocal Figure for a Joint—Definition of a Strut—Definition of a Tie—Stress Diagram—Determination of the Kind of Stress in a Bar—Firm Quadrilateral Frame—Firm Triangular Frame—Firm Frame—Firm Frame with Mansard Outline—Questions.

Graphic Statics is the Science and Art of determining by scale drawings the total stresses in the various parts of a structure. The forces transmitted through each part of a structure may be ascertained either by calculation or by graphical construction. The former method is extremely tedious, except in very simple cases, whereas the latter is not only rapid, but also affords a self-evident means of checking the accuracy of the solution.

DEFINITION.—**A Framed Structure consists of an assemblage of rigid bars, so arranged, that the stresses in them are principally push or pull and by the use of which, external forces may be transmitted or modified.**

A structure is different from a machine in so far as, the former transmits force while the latter transmits energy. This means that the parts of a structure are assumed to be at rest while those of a machine must be in motion.

In this section we assume the following, unless otherwise stated:—

(1) That the point of crossing of two or more bars is a joint and perfectly frictionless.

(2) That all the members or bars are able to withstand either push or pull.

(3) That each bar is incapable of being perceptibly deformed under the action of the stress it may have to carry.

For the complete specification of a force, we must know the following four elements:—

(1) The point or place of application.
(2) The line of action—*i.e.*, the line along which the force is acting.
(3) The direction or way the force acts along its line of action.
(4) The magnitude—*i.e.*, the number of units of force.

Classification of Frames.—(1) **Firm Frames** are those which have *just* sufficient bars to prevent change of shape, and any bar may therefore be lengthened or shortened without stressing any of the other members.

(2) **Deficient Frames** are those which have *not* sufficient bars to prevent deformation, and the joints must therefore be made stiff in order to resist change of form.

(3) **Redundant Frames** are those which have *more* bars than are necessary to resist distortion. In frames of this kind we cannot alter the length of certain bars without stressing one or more of the other members. Further, the frame may be self stressed if the redundant bars be badly fitted, and the stresses in the various members are indeterminate unless their yieldingness be taken into account.

Conditions of Equilibrium.—There must be no translation. This is assured if the diagram of external forces is a closed polygon.

There must be no rotation. This is satisfied if:—

(1) The external forces have no resultant moment round every point that may be chosen.

(2) The line of action of the resultant of all except two of the forces passes through the point of intersection of the lines of action of these two forces.

If a number of external forces act upon a structure and keep it at rest, and, if we have to determine graphically the relations among these external forces, we must know at least:—

Either.—All the elements of all the forces except one and nothing about that one.

Or.—All the elements of all the forces except two, and about one of these two its line of action. About the other, one point in its line of action.

In the former case, we determine the resultant of all the given external forces by any method, and the last or balancing force (that is, the one we know nothing about) has (1) its point of application anywhere in the line of action of the resultant, (2) its line of action coincident with the line of action of the resultant, (3) its direction or way opposite to that of the resultant, and (4) its magnitude is the same as that of the resultant.

The second case will be clear by a reference to Fig. 1.

B A is the resultant of the external forces, 1.2.3...(n – 2), acting on the body or frame. D C is the line of action of the

$(n-1)^{th}$ force, and E the point chosen as a point in the line of action of the nth force.

If three forces act upon a body and keep it at rest their lines of action must all pass through one point. Thereby, the line of action F E, of the nth force may be determined, since it must pass through O the point of intersection of B A with D C. Then by an application of the triangle of forces the magnitudes and ways or directions of the $(n-1)^{th}$ and n^{th} forces may be determined.

Bow's Method of Lettering.—In Fig. 2 we have an example of Bow's method of lettering a system of forces. It will be seen

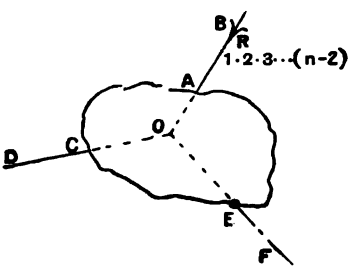

Fig. 1.—Relation among External Forces.

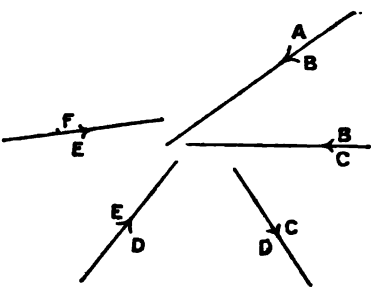

Fig. 2.—Illustration of Bow's Method of Lettering.

that every force has one letter on each side of its line of action. This is in order to name the force. Thus, we speak of the forces A B, B C, C D, D E, and E F. Again, each letter has been used twice, excepting A and F. This would indicate that one force was awanting or required to be determined:—viz., the force A F. This force may be the resultant or the equilibrant as the case may be; or, if on drawing the polygon of forces, F coincides with A (that is, the magnitude of F A is zero), then the system is in translationary equilibrium.

In Fig. 3, we have the forces acting at the joints of the triangular frame X Y Z, named by Bow's method.

The forces which keep in equilibrium the joints X, Y, and Z, are:—

For the joint X—

The force B C (all the elements of which are known).
The action of the stress * C D; and,
The action of the stress D B.

* As is usual, in treatises on this subject, the word *stress*, throughout Part IV., means the *total force* transmitted by the bar, and not the force per unit of cross area.

For the joint Z—

The action of the stress B D;
The action of the stress D A; and,
The supporting force A B.

And for the joint Y—

The action of the stress A D;
The action of the stress D C; and,
The supporting force C A.

The supporting force C A, has been represented by a curved dotted line to indicate that all we know about it is, its point of application.

The point X might be called the joint B C D; the point Y the joint C A D; and the point Z the joint A B D, since the letters naming a joint have been used to name the forces acting at that joint.

In Fig. 3, we have used the letters A, B, and C each four times and the letter D six times. In practice, this is avoided by lettering, as indicated in Fig. 4. Then the forces and bars will have the same names as before. Success in graphic solu-

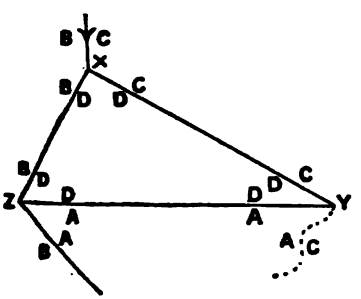

Fig. 3.—Bow's Method of Lettering a Triangular Frame.

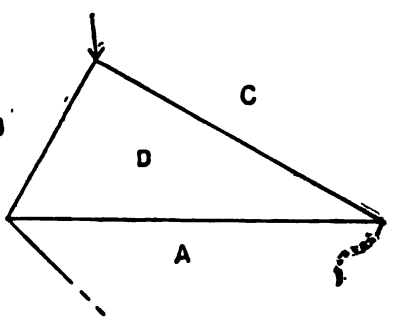

Fig. 4.—Bow's Method in Practice.

tions depends in a great measure on correct lettering, and on correct assumptions having been made, first, with regard to the total number of external forces that act on the frame, and second, with regard to what is known about the various elements of these external forces.

One great advantage of the Graphic Method of Solution is, that our attention is always being directed to the correctness of any assumptions that have been made. If the Stress Diagram

closes, we may safely consider the solution to be correct for the assumptions made; but, if it does not, some assumption is wrong or something has been left out.

Correct lettering is accomplished when every external force and every bar has one letter and only one on each side of it.

All the external forces must be applied at the joints of the frame, but if any should act at a point other than the end of a bar, then two equivalent parallel forces must be applied to the member under consideration, one at each end. By equivalent parallel forces is meant two forces which, applied as stated, would have the given force as their resultant.

The lines of action of the external forces must not fall inside the frame, but must be drawn outside, as in Fig. 4.

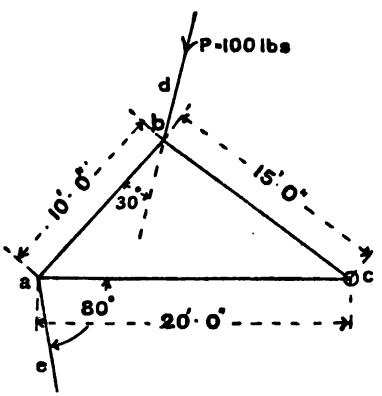

Fig. 5.—Sketch of Frame.

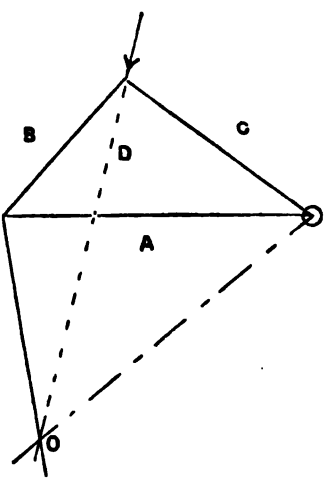

Fig. 6.—Frame Diagram.

Solution of a Triangular Frame.—*Given*, the triangular frame *a b c*, and the force P, completely specified as follows, viz. :—

Its point of application, *b*;
Its line of action, *d b*;
Its way or direction from *d* towards *b*; and,
Its magnitude, P lbs. Also,
The line of action of one of the supporting forces, *a e*.
And finally, a point *c*, in the line of action of the other supporting force.

It is required to find the remaining elements of the supporting forces, also the magnitudes and kind of stresses in the bars.

We begin by drawing the Frame Diagram (Fig. 6) to scale. This scale should be as large as possible, say, in this case, ¼ inch representing 1 foot. Then letter the Frame Diagram by Bow's method. Now, let the lines of action of the forces A B and B C, on being produced meet in O. Then *for no rotation*, the line of action of the other supporting force C A (as indicated by the chain dotted line) must pass through O, and also through the joint D C A, as given. Thus the line of action of the force C A is determined.

For no translation, the triangle of forces is applied, and will give the magnitudes and ways of the supporting forces, as indicated by Fig. 7. The scale used should be as large as convenient, say 1 inch representing 40 lbs.

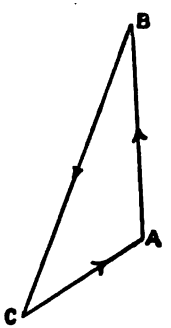

Fig. 7.—Diagram for External Forces.

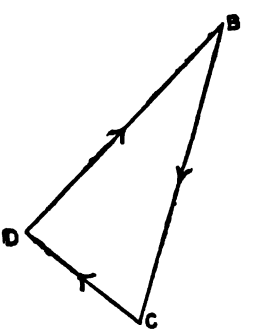

Fig. 8.—Reciprocal Figure for Joint B C D

Definition.—**If from a point, a number of lines radiate, and if a polygon be drawn which has its sides either all parallel to, or all at right angles to corresponding radiating lines, then this Polygon is called the Reciprocal of the Point.**

Thus, the triangle B C A, Fig. 7, may be called the reciprocal of the point B A C or O, in Fig. 6.

We can now draw the reciprocal figure for any one of the joints of the triangular frame. Because, we know all about the external forces acting at each of these joints; and further, not more than two bars meet at each joint.

If more than two bars meet at a joint, then we must know, in addition to all the external forces acting at that joint, the stresses in all the bars except two, before the reciprocal can be drawn.

Fig. 8 is the reciprocal figure for the joint B C D. It is drawn to the same scale and in exactly the same manner as Fig. 7, viz.:—B C parallel and equal to the external force B C; C D parallel to the bar C D; and D B parallel to the bar D B.

The length of the lines CD and B D, in Fig. 8 (measured to the same scale as that used for B C) determine the magnitudes of two forces which, acting in conjunction with the external force B C, would keep the joint B C D, at rest. The two forces C D and D B, are the actions on the joint of the stresses in the bars C D and D B, and therefore measure the magnitudes of the stresses in these bars. The arrow-heads give the ways or directions along the line of centres of the bars of the actions C D and D B.

Figs. 9 and 10 are drawn to the same scale and in the same way as Fig. 8, and represent the reciprocals for the joints B D A and A D C respectively.

From Figs. 9 and 10 we get similar information regarding the bars A D and D B, and their actions on the joint D B A, and the bars C D and D A, and their actions on the joint A D C, to that derived from Fig. 8 regarding the joint B C D.

In the reciprocal figure for the joint B C D, Fig. 8, the way

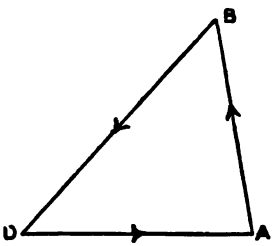

Fig. 9.—Reciprocal for Joint B D A.

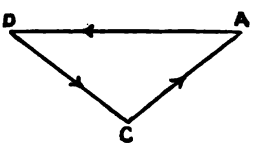

Fig. 10.—Reciprocal for Joint A D C.

of the action on the joint B C D, of the stress in the bar C D, is towards the left and upwards, while in Fig. 10 the way of the action of the stress in the same bar on the joint A D C, is towards the right and downwards.

We will now explain the cause of this apparent contradiction in the two reciprocals. The reciprocal for the joint B C D, shows that the way of the action on the joint B C D, of the stress in the bar D C, is towards the pin B C D—that is, pushing it. (This is indicated in Fig. 11 by the small arrow.) Then from Newton's third law the pin B C D, must push the bar with an equal and opposite force.

If the bar D C, pushes the pin B C D, it must also push the pin C A D. For this reason, that no bar can simultaneously push a pin at one end of itself and pull one at its other end. This is what the reciprocal for the joint A D C, indicates.

DEFINITION OF A STRUT.—When the reciprocal, for a joint indicates that the way of the action of the stress in a bar is towards the joint, then that bar is under compression and is called a strut.

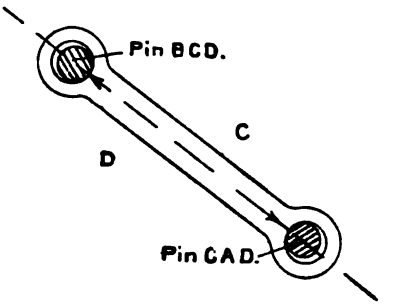

Fig. 11.—THE BAR C D.

On reference to the reciprocals for the joints B D A and A D C, it will be seen that the bar D A, is pulling at the pins B D A and A D C. But, by the action and reaction law, the pins will pull at the ends of the bar, and this means that the bar D A, is under tensional stress of an amount measured by the length of the line D A, in the reciprocal figures.

DEFINITION OF A TIE.—When the reciprocal for a joint indicates that the way of the action of the stress in a bar is away from the joint, then that bar is under tension, and is called a tie.

In Fig. 12, the reciprocals for the three joints of the frame and the one for the point O, have been combined into one diagram, which may be called either the Stress Diagram or the reciprocal of the Frame Diagram.

DEFINITION.—Two figures are reciprocal when every point in the one has a corresponding reciprocal in the other.

For example, the point C, in Fig. 12 has the lines D C, A C, and B C, meeting in it. If we refer to the Frame Diagram, Fig. 6, we find that, the bar C D, the force B C, and the force A C, form the reciprocal for this point C in Fig. 12.

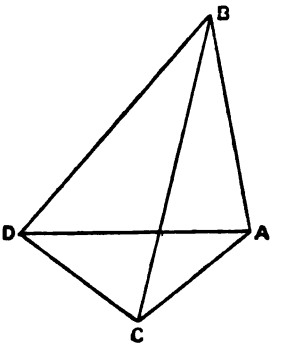

Fig. 12.—COMBINATION OF THE RECIPROCALS, OR STRESS DIAGRAM.

We do not put arrow heads on the Stress Diagrams; they would lead to confusion, and are quite unneces-

sary. Take for example the line A D, Fig. 12, from the reciprocal of the joint A B D, we would require an arrow head pointing from D towards A; while, from the reciprocal of the joint A D C, an arrow head would require to point the other way. (The double arrow on the line A D, points to the fact that a stress has no way.)

It will have been observed:—

(1) That when Figs. 7, 8, and 9 have been drawn they give all the information that was intended to be derived from drawing Fig. 10—viz., Fig. 8 gave the magnitude of C D, and Fig. 9 that of D A.

(2) That when we place the reciprocal for the joint A B D, on the reciprocal for the point O, as in Fig. 12, we have only to join D to C in order to complete the diagram.

These two observations point out that we have too much information; the excess is due to the finding of the point O. This frame is one of a class where we may find the stresses without first finding all the elements of the reactions or supporting forces.

Stress Diagram.—We shall now show how to determine the Stress Diagram direct from the Frame Diagram—*i.e.*, without first finding the reciprocals for the joints, and combining them into one.

It is quite immaterial as to which way we go round a structure —*i.e.* (referring to Fig. 6), whether we go from A to B and then to C, or the other way round. We shall find it to be an advantage to go round every structure in the same way as the hands of a watch. By doing so we shall find that the Stress Diagram will always lie to the left hand of the external force polygon. This will enable us to know where to begin the external force polygon in order to leave room for the Stress Diagram.

Referring to Fig. 6, where we are not supposed to know either the point O, or the line of action of the force C A, let us plot out therefrom the Stress Diagram, Fig. 12.

(1) Draw B C, in Fig. 12, parallel to the line of action of the external force B C in the Frame Diagram, Fig. 6, and containing 100 units, to some convenient scale, say 1 inch to represent 40 lbs. The correct lettering of this line is a very important part of the work. Since we are going round the frame in the direction of the hands of a watch—that is, from B to C—then B must be put at the top end and C at the bottom end of the line just drawn so as to indicate the way of the force correctly. If this point is attended to, little trouble will be experienced in drawing the diagrams.

(2) Draw from the last point found (viz., C) a line parallel to some force or bar which has C as one of the letters for its name; for example C D.

(3) Draw from the other end B of the line B C, a line parallel to the bar B D, and mark the point of crossing of the two lines D.

(4) Through D, the last point determined, draw D A parallel to the bar D A, and from some of the other points found draw a line parallel to a force whose line of action is known. Now, C A cannot be used because we only know its point of application, but we know the line of action of B A. Then drawing from B, in Fig. 12, a line parallel to the line of action of the supporting force A B, we determine the point A.

(5) On joining C with A we obtain a line parallel to the line of action of the supporting force C A, and the length of this line, C A, measures the magnitude of the force.

(6) Measuring the lines in Fig. 12 with the scale used to draw down the line B C, we obtain the magnitudes of the stresses in all the bars and of the two supporting forces.

How to Determine the kind of Stress in a Bar.—We will begin with the consideration of the forces which act on the left-hand joint—viz., the joint B D A, in Fig. 12.

Success in this part of the work depends almost entirely upon giving to each bar meeting in the joint under consideration its proper name—*i.e.*, by letters in their proper order.

Since we have gone round the external forces in drawing the Stress Diagram from B to C, &c.—that is, in the direction of the hands of a watch—we must go round each joint of the structure in the same way when naming the bars meeting in that joint.

The bars meeting in the joint B D A, would therefore be called, the bar B D, the bar D A, and the supporting force or reaction A B. Having thus determined the name of the bar, we then refer to the Stress Diagram in order to find the way in which the stress in that bar acts with regard to the joint.

Take for example the horizontal member in the Frame Diagram, Fig. 13 (this member is called the tie rod or tie beam, since it ties the lower ends of the rafters together), its name with reference to the joint B D A, is D A. Now, in the Stress Diagram D is on the left of A, and, therefore, the stress in the bar D A, acts from left to right (*i.e.*, from D to A) with respect to the pin at the joint B D A. This means that the bar D A, is pulling at the pin B D A, and therefore the pin B D A, pulls at the bar, thereby putting the bar into tension.

Similarly the stress in the bar B D (called a rafter) acts, so far as the joint B D A is concerned, in the direction indicated by B D in the Stress Diagram—that is, from B to D. The bar B D, is therefore pushing at the joint B D A, and is thus put into compression by the reaction of the pin B D A.

RULE TO DETERMINE THE KIND OF STRESS IN A BAR.—Take

the letters on each side of the Bar in the Frame Diagram, in the same order with respect to the joint on which the Bar acts, as we have taken the letters on each side of the External Forces acting on the Frame. Then along the line in the Stress Diagram, which is named after the Bar, from the first letter

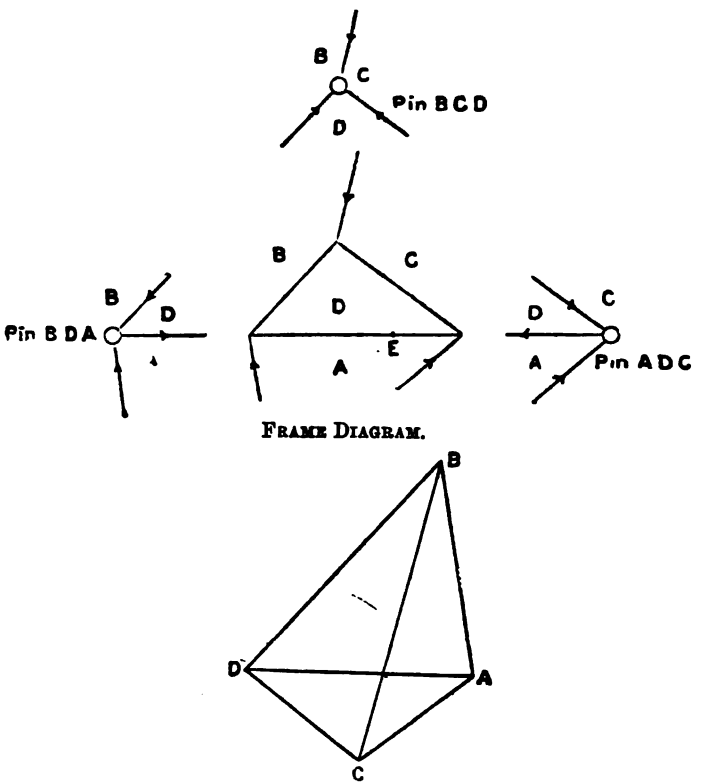

FRAME DIAGRAM.

STRESS DIAGRAM.

Fig. 13.—STRESS ACTION ON PINS.

towards the second, gives the way of the stress' action with respect to the joint under consideration. If the way is towards the joint the stress in the Bar is Compression or Push, and the Bar is called a Strut. If the way is away from the joint the stress is a Tension or Pull, and the Bar is called a Tie.

The above rule may also be applied to a point in a bar. Take, for example, the point E, in the tie rod, and suppose we want to find how the left-hand portion of the tie rod acts upon the section at E. Then the name of the left-hand portion of the tie rod with respect to E is A D, and from the Stress Diagram this acts from right to left—that is, away from E—and is therefore pulling at the section.

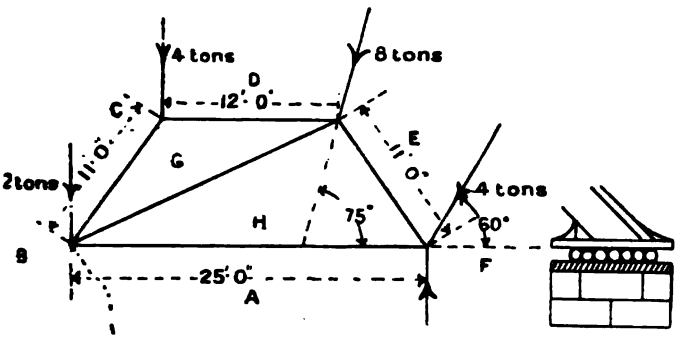

FIG. 14*a*.—FRAME DIAGRAM.

FRAME SOLVABLE WITHOUT KNOWING ALL ABOUT REACTIONS.

Notice that the tie rod, with respect to the left-hand joint, is called D A, and with respect to the right-hand joint would be called A D, and similarly with any other bar in the frame.

The above rule for the kind of stress does away with the use of arrow-heads and of supplementary diagrams.

The action of all the bars on the pins of the frame are shown in the small diagrams surrounding the Frame Diagram of Fig. 13.

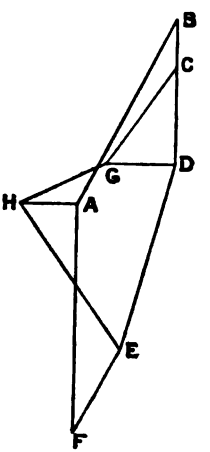

Fig. 14*b*.—STRESS DIAGRAM.

Firm Quadrilateral Frame.—This frame is one of a type which allows a solution to be found without having first determined all the elements of the reactions.

We shall assume that the right-hand end rests on rollers, as indicated in Fig. 14*a*. Consequently the line of action of the reaction is practically vertical. If it simply slides instead of rolling, then the reaction is inclined to the normal at an angle equal to the angle of friction, and inclined

to that side of the normal which will oppose the motion of the frame. The left-hand end of the frame in Fig. 14*a* is assumed to be anchored to the wall by bolts, &c. All we know about the left-hand reaction is its point of application.

If we suppose both ends of a frame to be anchored, then we only know the points of application of the reactions, and we assume that their lines of action are parallel to each other and to the line of action of the resultant of the external forces.

We begin by drawing the Frame Diagram to as large a scale as possible, and then indicate the external forces at the joints by their lines of action. The right-hand reaction is indicated by vertical line, and the left-hand reaction by a dotted curved line, as shown in Fig. 14*a*. We then letter the diagram according to Bow's method.

In drawing the Stress Diagrams, we shall always go round the Frame Diagrams clockways.

We begin by drawing a line parallel to the line of action of the first force or load B C. This line should contain as many units of length as B C contains units of force, which in this example is 2 tons.*

Then draw C D parallel to the line of action of the load C D, and containing 4 units of length corresponding to the 4 tons load. Next draw D E parallel to the line of action of the load D E, and E F parallel to the line of action of the load E F, representing 8 units and 4 units, respectively.

The line B C D E F is called the Line of Loads.

In order to complete the Stress Diagram we shall begin with the joint C D G, which is the only joint of which we have sufficient data. Draw from the point C in the "Line of Loads" a line parallel to the bar C G, and from D a line parallel to the bar D G. The intersection of these two lines is called the point G. From G draw G H parallel to the bar G H, and from E draw E H parallel to the bar E H. This determines the point H. Then draw H A parallel to the bar H A, and from F draw a line parallel to the line of action of the reaction F A. The intersection of these two lines fixes the point A. Joining A with B gives the finishing line of the Stress Diagram. The line A B in the Stress Diagram is parallel to the line of action of the left-hand reaction.

By applying the rule for the kind of stress, we can determine from the diagram all we may wish to know—*e.g.*, with respect to the top right-hand joint, the diagonal member is called H G.

* The scale for the diagram should be as large as convenient. A rough guess may be made by adding all the loads together, and assuming that this will be the total vertical length of the diagram.

On reference to the Stress Diagram we see that the way of its action is from H to G which means pushing at the joint. Therefore, the diagonal member is in compression, and so on for the other members.

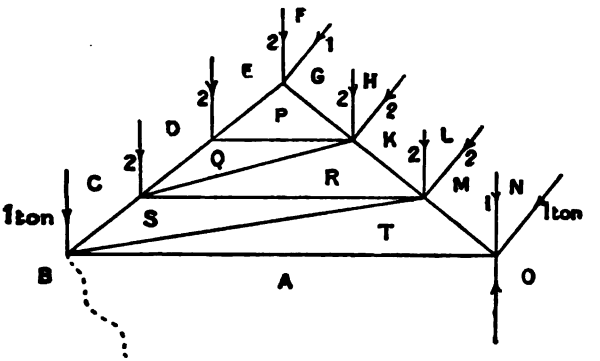

FIG. 15a.—FRAME DIAGRAM.
FRAME WITH WIND PRESSURE.

The magnitudes of the stresses are measured by the lengths of the lines in the Stress Diagram.

The polygon BCDEFA is called the polygon of external forces.

Firm Triangular Frame.—This frame, Fig. 15a, can also be solved without knowing all about the reactions.

The right-hand end of the frame is assumed to be resting on rollers, while the left-hand end is anchored to the wall. The vertical loads on the Frame Diagram represent the action of gravity on the roofing, such as slates, &c., which is assumed to be uniformly distributed over the surface.

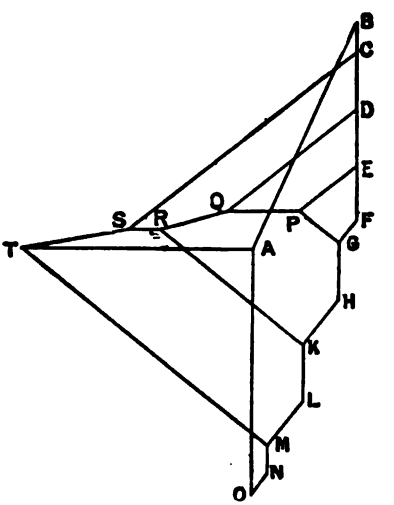

FIG. 15b.—STRESS DIAGRAM.

In Fig. 15a, the rafters are shown divided into three equal

parts called bays; and, since the joint at each end of a bay must carry one half of the uniformly distributed load over that bay,

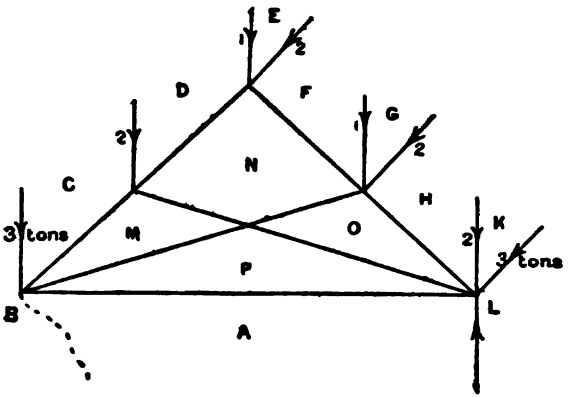

FIG. 16a.—FRAME DIAGRAM.
FIRM FRAME WITH A QUADRILATERAL PART.

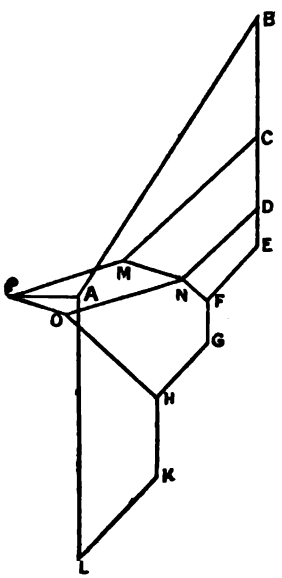

FIG. 16b.—STRESS DIAGRAM.

the vertical loads will have the proportions shown by the numbers on the Frame Diagram. Wind pressure is also assumed to be uniformly distributed, and is reckoned as so many lbs. per square foot normal to the rafters. This is indicated on the right-hand side of the Frame Diagram.

Note.—When wind pressure acts on the rafter which is anchored, the stresses in the members of the frame are more severe than when it acts on the free rafter. This should be remembered when designing a roof.

Since we know all the elements of the external forces, the line of loads may be drawn as in Fig. 14*b*.

Therefore, in order to complete the Stress Diagram we can begin at the top joint of the Frame Diagram where only two members meet. This enables us to find first the point P in the Stress Diagram, then the point Q, and so on.

Firm Frame.—The frame represented in Fig. 16*a* is of the same class as the two preceding. In drawing the Stress

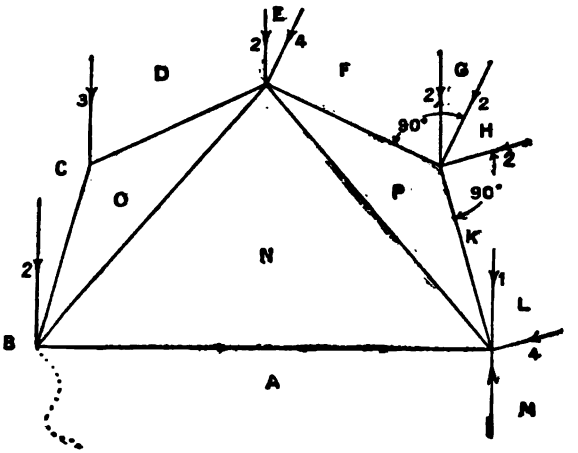

FIG. 17*a*.—FRAME DIAGRAM.

FIRM FRAME WITH MANSARD OUTLINE.

Diagram, although we have determined the point N and the point M, we cannot fix the point P, until we obtain the point O. After that, the diagram closes in the usual way.

Firm Frame with Mansard Outline.—In Fig. 17*a* we have illustrated a frame having the double-sloped outline of the Mansard Roof. It is of the same type as Fig. 16*a*, and presents the same peculiarity in the drawing of the Stress Diagram. Wind pressure is indicated on the right-hand rafters. The forces E F and G H are both normal to the bar F P. *They should, however, be of equal value.* Also, the forces H K and L M are both perpendicular to the bar K P.

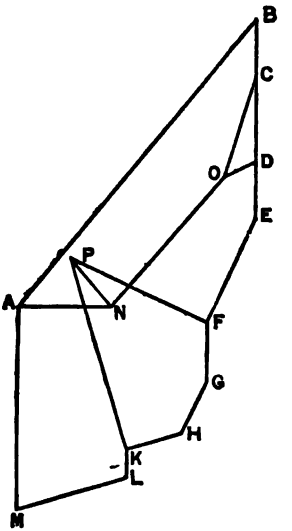

FIG. 17*b*.—STRESS DIAGRAM.

LECTURE XXIV.—QUESTIONS.

1. What is a frame or framed structure? Distinguish between the three different kinds of frames.
2. Explain in your own words Bow's method of lettering a system of forces, with two examples.
3. What is meant by the reciprocal of a point, and a pair of reciprocal figures?
4. Explain how you would represent forces in a diagram so as to determine those in each part of a structure, and explain the principles upon which the construction depends.
5. State a rule for determining the kind of stress in a bar.
6. Illustrate and explain how you would find the stresses in a firm quadrilateral frame.
7. Illustrate and explain how you would find the stresses in a firm triangular frame.
8. Illustrate and explain how you would find the stresses in the outline of a Mansard frame.

LECTURE XXV.

CONTENTS.—Substituted Frames—King Post Truss—Right-Angled Strut Truss—Roof Truss—Load at an Internal Joint of a Frame—Modified French Truss—Bowstring Truss—Questions.

Substituted Frames.—The types of frames illustrated in the previous Lecture, although not practical examples, are intended to be substituted for some other actual form in order to determine the reactions therein, since the reactions do not depend upon the form of frame carrying the roofing, but merely on the distribution of the loads. In substituting one of the above frames for a practical one, we must have the joints of the substituted frame coincident with those of the given one. This will be illustrated by the following examples :—

King-Post Truss.—In Fig. 18 we have the Frame Diagram of a king post truss with wind pressure on the right-hand rafter. In this case, we assume both rafters to be anchored to the walls. Therefore, all we know about the elements of the reactions are

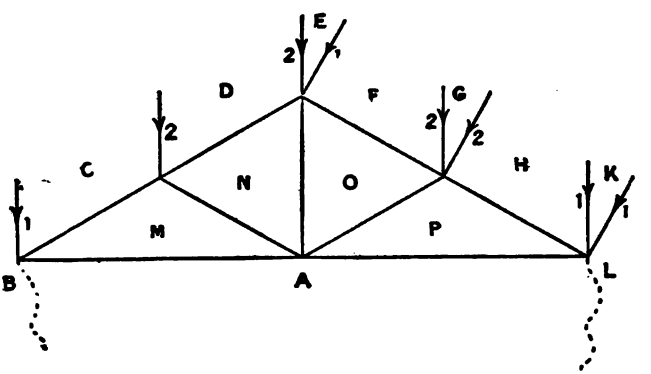

FIG. 18.—FRAME DIAGRAM OF KING POST TRUSS.

their points of application, and that their lines of action are parallel to each other, as well as to the line of action of the resultant of the external forces.

Before we can determine the Stress Diagram for this frame we must first determine the reactions, because more than two bars

meet in each of the joints except the two where the reactions act. Consequently, until we determine all the elements of the reactions we cannot begin at either of these two joints.

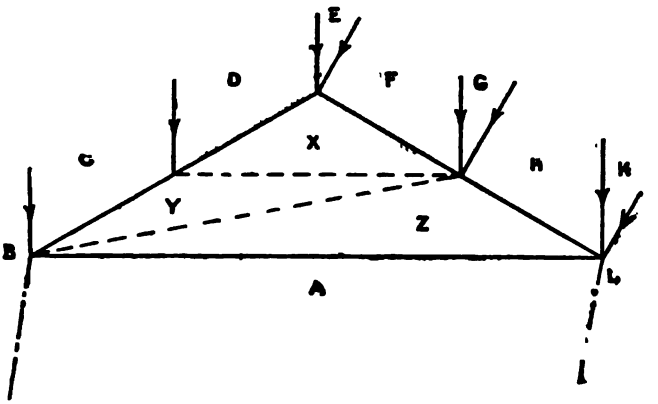

FIG. 19.—SUBSTITUTED FRAME.

In order to determine the reactions, we shall substitute a frame similar to that illustrated in Fig. 15*a*. This substituted

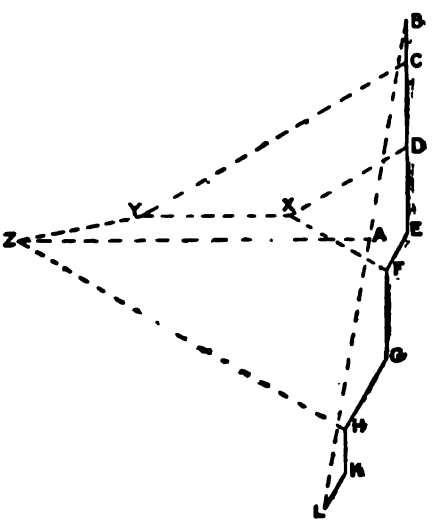

FIG. 20.—STRESS DIAGRAM FOR SUBSTITUTED FRAME.

frame is shown in Fig. 19. In practice, this frame is merely sketched in order to apply the proper letters. The dotted lines are drawn in the Frame Diagram, or the set square is simply made to pass through the requisite joints, and then the lines are drawn parallel thereto in the Stress Diagram. To obtain Fig. 20 we begin by drawing the line of loads. Then, we find the point X, when a line from the point X drawn parallel to the substituted bar X Y, and one from the point C parallel to the rafter C Y fix the point Y. Next we find the point Z. Now, the line of action of the resultant of the external forces is

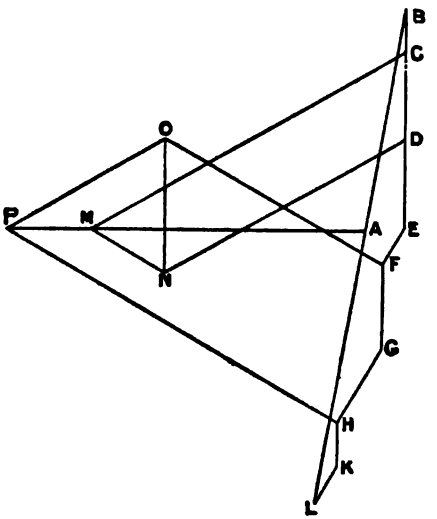

FIG. 21.—STRESS DIAGRAM FOR KING POST TRUSS.

parallel to the line joining L with B. Therefore, the point A must lie on this line since the reactions L A and A B are parallel to each other and to the line of action of this resultant. Consequently, we find the point A by drawing through the point Z a line parallel to the bar Z A so as to intersect L B in the point A. This determines all the remaining elements of the reactions, viz.:—

(1) Their lines of action parallel to L A and A B.

(2) Their ways from L towards A, and from A towards B.

(3) Their magnitudes by the number of units of length in the lines L A and A B.

We can now draw the Stress Diagram for the king post truss,

as shown in Fig. 21, from which the particulars for the various members may be determined. Comparing Fig. 21 with Fig. 20, we see that nearly all the lines of Fig. 21 lie along the lines of Fig. 20. In practice we simply draw Fig. 21 on the top of Fig. 20.

This method of a substituted frame introduces fewer errors due to drawing, than the usual method of the funicular polygon (which will be illustrated further on), because we make use of the same joints of the frame for the two Figs. 20 and 21, and the same line of loads.

There is one line in Fig. 21 which will check the accuracy of the Stress Diagram. In drawing the diagram we begin with the point M, and then find the points N, O, and P. The line joining P to H will then be parallel to the rafter P H, if the Stress Diagram is correct.

Right-Angled Strut Truss.—In this frame we have introduced loads at the lower joints as well as roofing weights and wind

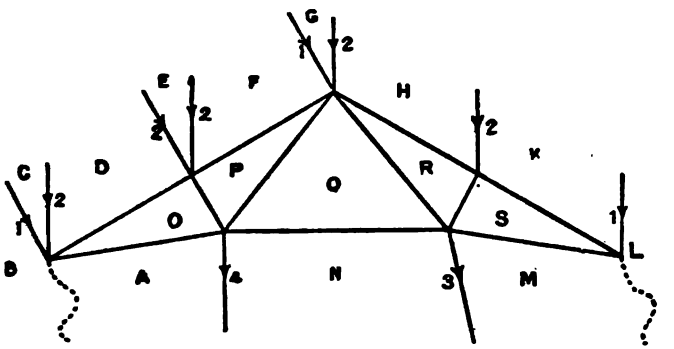

FIG. 22.—FRAME DIAGRAM FOR RIGHT-ANGLED STRUT TRUSS.

pressure. We also assume the two rafters to be anchored to the walls, as indicated by the two dotted curved lines L M and A B.

We must first find the reactions before we can draw the Stress Diagram. In finding the reactions we will substitute the frame which is shown in Fig. 23.

FIRST METHOD OF OBTAINING STRESS DIAGRAM FOR ORIGINAL FRAME.—Produce the lines of action of the loads at the lower joints until they intersect the rafters. These points of intersection are considered as joints in arranging the substituted frame and the lower loads assumed to be acting at these joints

as shown in Fig. 23. The forces fF and H h in Fig. 23 are the loads N A and M N in Fig. 22 transferred as explained.

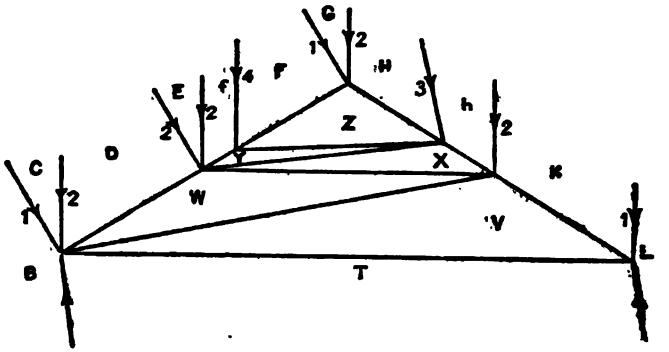

FIG. 23.—SUBSTITUTED FRAME.

The Stress Diagram for the substituted frame is illustrated in Fig. 24 and presents no difficulty requiring explanation. This diagram gives the reactions L T and T B.

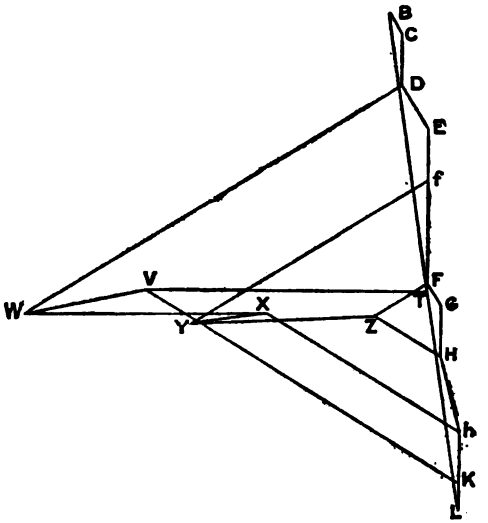

FIG. 24.—STRESS DIAGRAM FOR SUBSTITUTED FRAME.

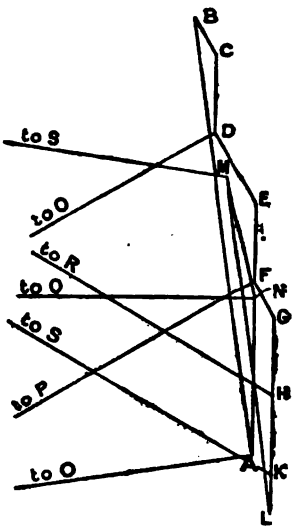

FIG. 25.—STRESS DIAGRAM FOR ORIGINAL FRAME.

In order to draw the Stress Diagram for the original frame which is illustrated in Fig. 25, it is necessary to redraw the line of loads taking them in their order as in Fig. 22. That is, B C,

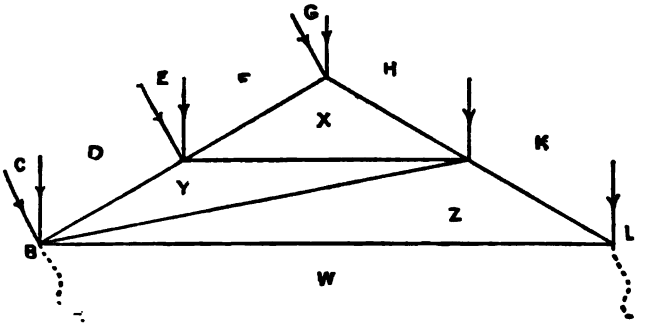

FIG. 26a.—FRAME DIAGRAM.
SUBSTITUTED FRAME FOR TOP JOINT LOADS.

CD, DE, EF, FG, GH, HK, KL, reaction LM, MN, NA and then reaction AB. The drawing of the remaining part of the Stress Diagram calls for no special remark. (The above Stress Diagram is not completed for want of space.)

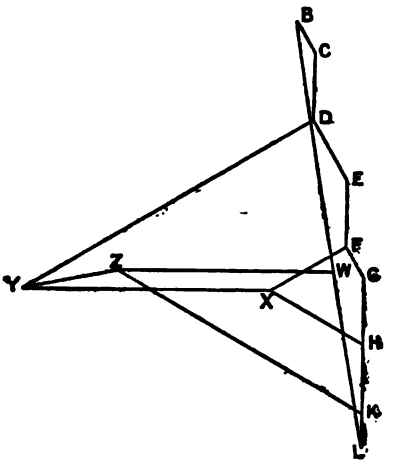

FIG. 26b.—STRESS DIAGRAM.

SECOND METHOD.—Take the top joint and the lower joint loads separately. In Fig. 26 we have the substituted frame for the top joint loads and its Stress Diagram. The Stress Diagram, Fig. 26b, determines the reactions LW and WB due to the loading on the rafters.

In Fig. 27 we have a frame similar to the one illustrated in Fig. 14a. The joint A N S is any point in the line of action of the load N A in Fig. 22, and the joint N M R S any point in the line of action of the load M N in Fig. 22. The left and right hand lower ioints of Fig. 27 are the rafter ends in Fig. 22

In Fig. 27 the load T A is the reaction W B found in Fig. 26*b* reversed. The loads A N and N M are the loads at the lower

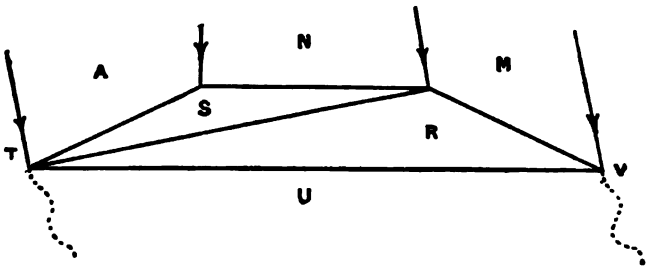

FIG. 27.—SUBSTITUTED FRAME DIAGRAM FOR LOWER JOINT LOADS.

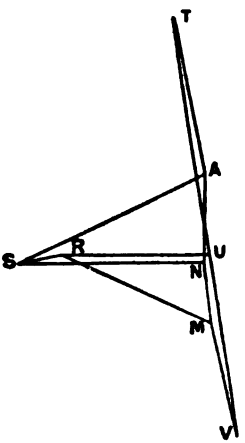

FIG. 28.—STRESS DIAGRAM FOR FRAME IN FIG. 27.

joints in Fig. 22, and the load M V is the reaction L W of Fig. 26*b* reversed. Therefore, if we draw the Stress Diagram for the frame of Fig. 27 we determine the reactions due to all the loads of the original frame of Fig. 22.

In Fig. 28 we have the Stress Diagram for the frame of Fig. 27. The reactions are represented by the lines V U and U T. This figure has been drawn to a smaller scale than Fig. 24, but the lines V U and U T of Fig. 28 contain the same number of units as L T and T B of Fig. 24.

Roof Truss.—In Fig. 29 we have a frame of a type that will not allow of the Stress Diagram being drawn in a regular manner, but only in a step by step process.

Fig. 30 shows the substituted frame used in order to determine the reactions L A and A B, and in Fig. 31 we have the Stress Diagram for both Figs. 29 and 30.

In Fig. 31 we draw first the line of loads, second we find the point O, then O X and D X fix the point X, and X Y and K Y fix the point Y. On drawing Y A parallel to the bar Y A, and L A parallel to the line of action of the reaction at the right-hand joint, we determine the reactions L A and A B.

The point O is the same in both Stress Diagrams, but we

cannot determine the points N and Q until we have found the points M and R. The point M is found by drawing D M

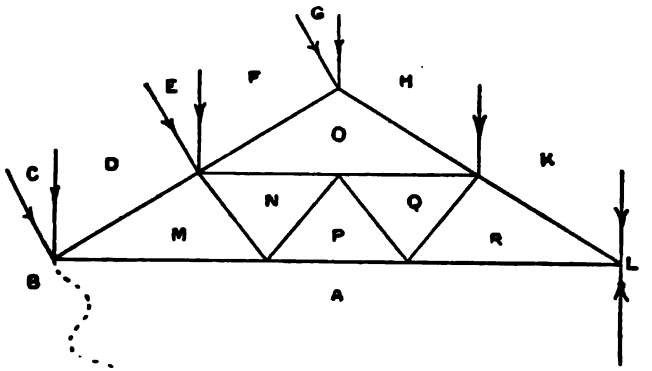

FIG. 29.—FRAME DIAGRAM OF ROOF TRUSS.

parallel to the rafter D M, and A M parallel to the tie-bar A M; then M N and N O fix the point N, and similarly for the point

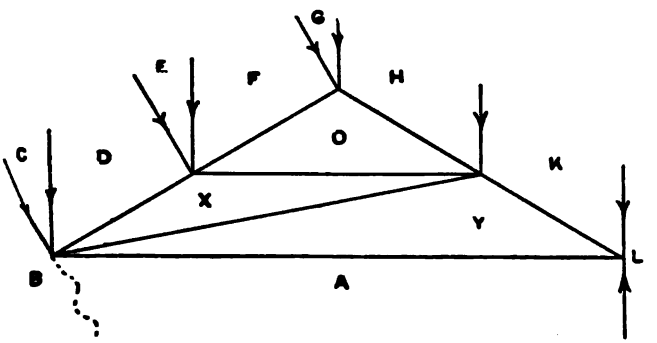

FIG. 30.—SUBSTITUTED FRAME FOR FIG. 29.

Q. Again, although N may be determined, P cannot be fixed until we have found Q.

The line N P or P Q forms a check line.

Note.—The dotted lines of Fig. 31 *are the only part of the Stress Diagram for the substituted frame that has not been required for the original frame.*

Load at an Internal Joint of a Frame.—In Fig. 32*a* we have a frame the same as the last one, but with a load applied at a joint inside the frame. This load is represented in the Frame Diagram by the small arrow near the letter P, and is applied at the joint O P Q T.

Note.—If the force had been applied at a point in the bar, then equivalent parallel forces *applied to the joints at the end of the bar will allow a solution to be determined.*

To obtain a solution for this frame loaded as shown, introduce a bar with its centre line lying along the line of action of

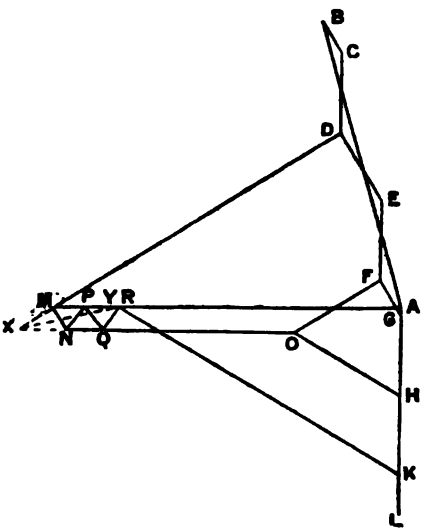

FIG. 31.—STRESS DIAGRAM FOR BOTH ROOF TRUSS AND SUBSTITUTED FRAME.

the given force. Then, where this bar cuts an outside member of the frame, apply a force having all its elements (excepting the point of application) the same as those of the given load.

The introduced bar is represented in Fig. 32*a* by the dotted line S T, and the applied force by the chain dotted line M A. The force M A will have the same action on the members of the frame through the bar S T, that the load at the joint O P Q T has, therefore the load must be left out after M A is applied.

Note.—The introduced bar might have been placed between the

*joint where the load is acting and the rafter, and the equivalent force applied at the rafter end of the bar.**

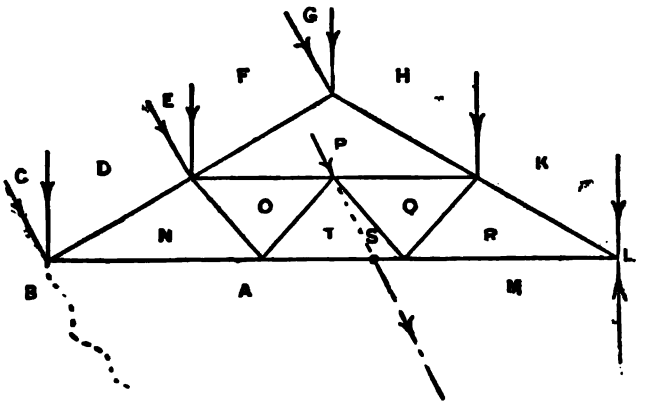

FIG. 32*a*.—FRAME DIAGRAM.
ROOF TRUSS, WITH LOAD AT INTERNAL JOINT.

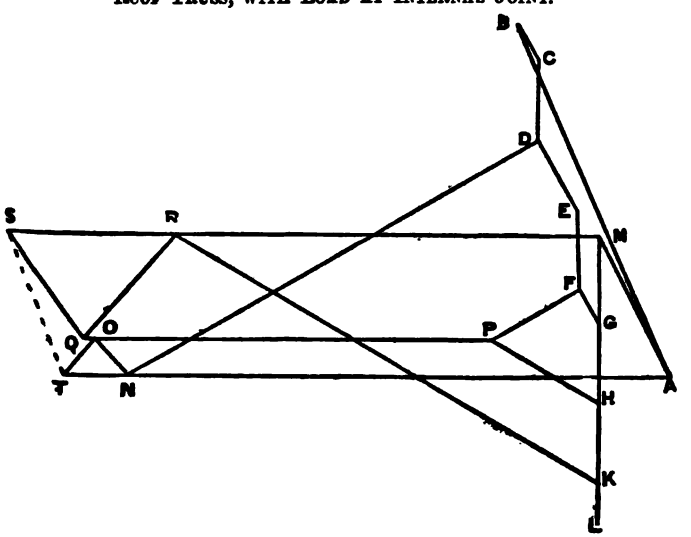

FIG. 32*b*.—STRESS DIAGRAM.

* The student should work this method as an exercise. Some of the lines of the Stress Diagram will be lowered but the stresses will remain unchanged.

The Frame Diagram, Fig. 32*a*, is loaded similarly to the frame of Fig. 22. The reactions are therefore found in the same way.

After the external force polygon has been drawn, the Stress

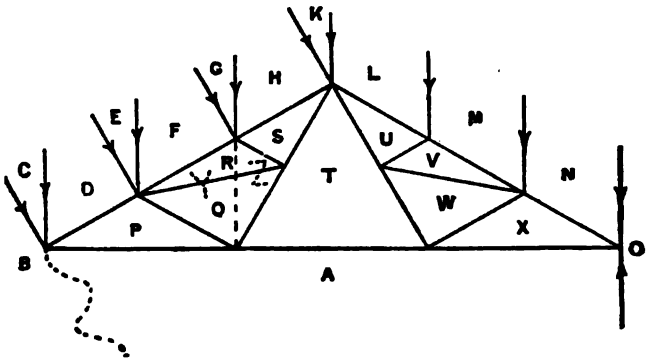

FIG. 33*a*.—FRAME DIAGRAM.

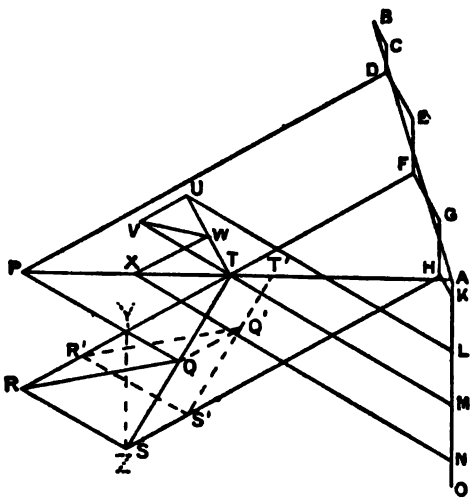

FIG. 33*b*.—STRESS DIAGRAM.

FRAME REQUIRING SPECIAL METHODS FOR SOLUTION.

Diagram may be completed by the same method as that used for the frame of Fig. 29.

Referring to the Stress Diagram of Fig. 32*a*, we see that the

bar T S exerts the same pull at the joint T S M A as the force M A. These two therefore balance each other, and we are left with the pull which the bar S T exerts on the joint O P Q T. This pull S T, on the joint O P Q T, is identical in all its elements with the load; and therefore, the stresses in the members of the frame will be identical with those due to the original load.

Modified French Truss.—This Truss is illustrated in Fig. 33*a*, and presents some difficulties in its solution. We first determine the reactions as already explained and draw the external force polygon as in Fig. 33*b*. Secondly, we draw D P and A P parallel to the bars D P and A P respectively. This fixes the point P. But, although we know the point P, we can get neither Q nor R, nor any other point but X. This point X, however, does not help us, because we can proceed no further by aid thereof with the Stress Diagram.

First Method of Obtaining the Stress Diagram.—We know that the point R lies on a line drawn through F parallel to the bar F R and that S lies on a line drawn through H parallel to the bar H S. Now, assume a point R′ anywhere on the line F R and draw R′ S′ parallel to the bar R S and H S′ parallel to the bar H S. This fixes the point S′. Then S′ T′ and A T′ fix the point T′, and R′ Q′ and T′ Q′ fix the point Q′. Next move the figure R′ S′ Q′ parallel to itself keeping R′ on the line F R until Q′ lies on a line drawn through P parallel to the bar P Q. This is done by drawing Q′ Q parallel to F R so as to intersect P Q in Q. This determines the point Q. Then Q S and H S fix S and Q R and F R fix R and so on for the other points.

Second Method.—Substitute the bar Y Z (as shown by the dotted line in the Frame Diagram, Fig. 33*a*) for the two bars Q R and R S. This bar transfers the action of the loads at the joint G H S R F to the joint P Q T A; and therefore, the stress in T A will be unaffected. If the bar H S had been divided and similarly braced, then a bar from that joint to the joint P Q T A would enable a solution to be found.

In the Stress Diagram, Fig. 33*b*, we begin by finding the point P, then the points Y, Z, and T respectively. Having found the point T we can then proceed to find the other points in the same way in the previous cases.

Third Method.—First, find the stress in the bar T A, by taking one of the sections of the truss and thus obtain the resultant of the loads and the reaction of the wall on that section. Second, ascertain what stress in T A combined with the reaction of the other section of the truss on the apex will

balance this resultant. Fig. 34 represents the right-hand section of the Truss of Fig. 33*a*. There is no wind pressure on this side. The loading consists of $\frac{1}{2}$ K L, L M, M N and N O in Fig. 33*a*. The resultant K′ O, Fig. 34, of these four loads passes through the centre of the rafter since N O is equal to $\frac{1}{2}$ K L and L M is equal to M N.

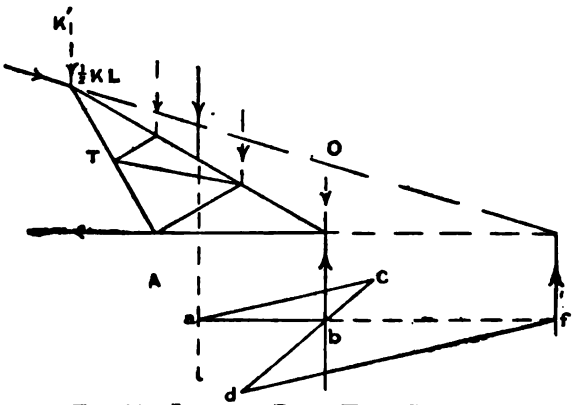

FIG. 34.—LOADS ON RIGHT-HAND SECTION.

We have now to find the resultant of K′ O and the reaction O A. Draw the line *a b* anywhere cutting the lines of action of the forces K′ O and O A as shown in Fig. 34. Through *b* draw *c d* at any angle to *a b*. Make *b c* represent to scale the force K′ O and *c d* to the same scale the reaction O A. Then join *a* with *c* and through *d* draw *d f* parallel to *a c*, so as to intersect *a b* produced in *f*. Then *f* is a point in the line of action of the resultant of the forces K′ O and O A. Its line of action is parallel to the lines of action of the forces K′ O and O A, and its magnitude is equal to their difference—that is, K′ A in Fig. 35.

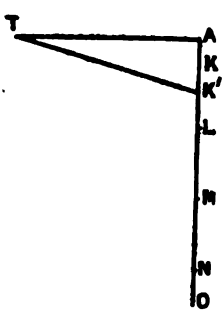

FIG. 35.—TRIANGLE OF FORCES ON SECTION.

Next produce the centre line of the bar T A in Fig. 34 to intersect the line of action of K′ A, the resultant of the two forces K′ O and O A. Then since the resultant K′ A, the action of the stress in the bar T A, and the action T K′ (*i.e.*, the reaction of the left-hand section on the apex of the frame) form a system of

forces in equilibrium. The line of action of the force T K′ must pass through the apex and the intersection of T A and

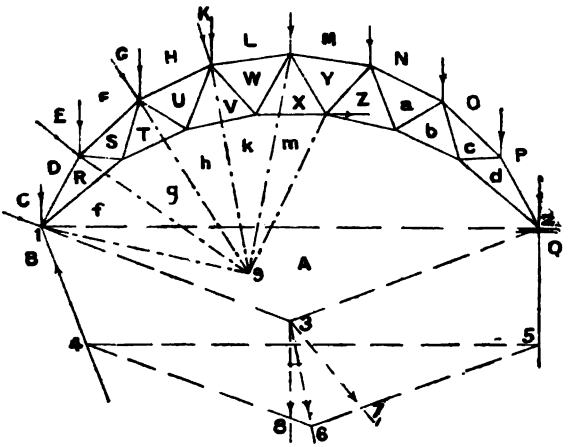

FIG. 36*a*.—FRAME DIAGRAM. BOWSTRING TRUSS.

K′ A, consequently an application of the triangle of forces will give the value of the stress in T A. This is shown in Fig. 35, where K′ is the centre of K L and the other points are points in the line of loads as in Fig. 33*b*. When this is known, the Stress Diagram can be completed.

Bowstring Truss.—There is no difficulty in drawing the Stress Diagram for this truss, but if we commence in the usual manner by drawing D R and A R, by the time we get to the other side, the finishing line would most probably not be parallel to its corresponding bar in the Frame Diagram. This is due to the short

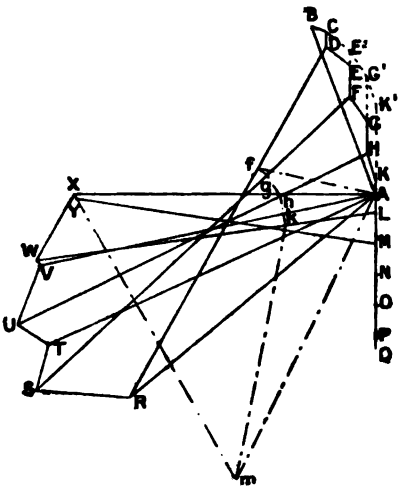

FIG. 36*b*.—STRESS DIAGRAM.

length of the bars R S, S T, &c., in the Frame Diagram and to the stresses in them being large compared to the loading on the roof as shown by the Stress Diagram.

We get a very much better diagram by determining the stress in one of the centre ties—*e.g.*, A X, by aid of a supplementary frame. Therefore, in order to find the reactions, the wind pressure may be supposed to act on a surface tangential to the curve of the roof at the joints; the length of the surface being equal to the sum of the two half bays on each side of the joint. The wind pressure at each joint will act along the radial line at the joint, and therefore the resultant of the wind pressures must pass through the centre of the outer curved flange.

The point 3 in the Frame Diagram, Fig. 36*a*, is the centre of the outer curved flange. This is a point in the line of action of the resultant wind pressure. This line is parallel to the line joining B with K′ in the Stress Diagram, and is represented by the line 3—7 in the Frame Diagram. B C, C E′, E′ G′, and G′ K′ represent the wind pressures B C, D E, F G and H K and therefore B K′ is the resultant in magnitude and is parallel to its line of action.

If the roofing is uniform, the centre of the curve of the outer flange will be a point in the line of action of the resultant load. Therefore, the resultant of the wind pressure and of the roofing weight will also pass through the point 3. The line of action of this resultant will be parallel to the line joining B with Q in the Stress Diagram—*i.e.*, along the line 3—6 in the Frame Diagram. The Truss is in equilibrium under the resultant load acting along the line 3—6. The line of action of the right-hand reaction is known, and the point of application of the left-hand reaction is also known. These three forces must pass through one point. Therefore the line joining the point 1 with the point where the line 3—6 cuts the line 2—5 will give the line of action of the left-hand reaction. But as the point of intersection of the lines 3—6 and 2—5 would be far off the paper we use the following construction:—Join the point 1 with 2, 2 with 3, and 3 with 1; then take any point 5 in the line of action of the right-hand reaction and draw 5—6 parallel to 2—3. Then draw 6—4 parallel to 3—1 and 5—4 parallel to 2—1 so as to intersect 6—4 in the point 4. If the point 1 be joined with the point 4 the the line 1—4 will pass through the point of intersection of the line 3—6 with the line 2—5. The line 1—4 is therefore the line of action of the left-hand reaction.

In the Stress Diagram, Fig. 36*b*, draw a line through the point B parallel to the line 1—4, so as to intersect the line Q A in the point A. This determines the reactions and enables us to proceed with the Stress Diagram.

We shall first determine the stress in X A. Assume a point 9 anywhere and connect it as indicated by the chain dotted lines in the Frame Diagram. This point 9, when connected with the joints of the outer flange, forms a supplementary frame in equilibrium under the following forces:—

(1) The wind pressure.
(2) The loads C D, E F, G H, K L and L M.
(3) The reaction A B.
(4) The action of the stress M Y on the joint L M Y X W.
(5) The action of the stresses in Y Z and Z A on the joint X Y Z A.

In the meantime, the internal bars R A, R S, S T, T A, on to W X and X A are left out of account.

In the Stress Diagram, Fig. 36*b*, we begin by drawing A*f* parallel to the supplementary bar A*f* and D*f* parallel to the bar D*f*. This fixes the point *f*. Then *f g* and F*g* give the point *g* and so on until the point *m* is obtained. Now draw *m* Y parallel to the bar *m* Y (which is coincident with the bar X Y) and M Y parallel to the bar M Y this fixes the point Y. In a similar way Y X and A X fix the point X, when the Stress Diagram may then be finished in the usual way. This method gives

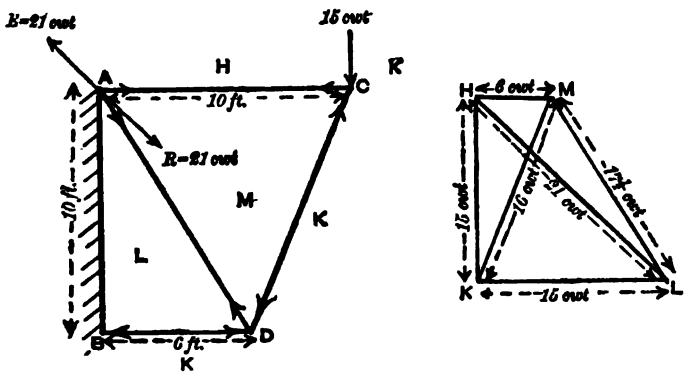

To Illustrate Example I.

a more accurate estimate of the several stresses than by following the usual direct plan, as explained at the beginning of this example. Moreover, this construction is perfectly general in its application and may be used to determine the stress in any one bar of a frame.

Example I.—A is a point in a wall 10 feet vertically over another point B. From A and B there project two horizontal

bars, A C, B D (the former being 10 feet and the latter 6 feet long), and D is joined by two bars with A and C. If a weight of 15 cwts. be hung from C, find the stresses on all the bars, and show which are in tension. Find also the resultant stress on the point A. You may neglect the weights of the bars.

ANSWER.—In the figure we have denoted the spaces by letters according to Bow's notation. To obtain the Stress Diagram we must draw H K parallel to the force H K and 15 units long. Then make H M parallel to the bar H M and K M to the bar K M. This gives us the point M. M L parallel to the bar M L, and K L to the bar K L, fix the point L. H L, when joined, gives the reaction at the joint A, and the other lines the stresses in the bars. Their values are marked on the figure. A C and A D are in tension, while C D and B D are in compression.

LECTURE XXV.—QUESTIONS.

1. A king post truss, whose height is one-fourth of its span, is loaded at the joints with vertical loads of 15, 30, and 45 units respectively. Determine the nature and amount of the stresses in each member of the frame. (S. & A. Adv. Exam., 1896.)

2. A roof of 28 feet span, height 7 feet, rests on king-post trusses, 10 feet apart. The weight of the roof is 20 lbs. per square foot. Find the stresses on each part.

3. If the above roof has a wind pressure of 40 lbs per square foot on one side, find the stresses on each part.

4. A roof of the form shown in Fig. 22, is 40 feet span and 10 feet high. The horizontal tie-bar is 8 feet below the vertex. Find the stresses in each part when loaded with 2 tons at each joint.

5. If, in the previous question, the maximum wind pressure on one side be 2 tons on each bay, find the stresses on all the bars.

6. Suppose both ends of the roof truss in Fig. 29 are anchored, and that in the substituted frame the bar X Y slopes in the opposite direction to that in Fig. 30; find the reactions and the stresses in the roof truss.

7. Work out the stresses for Fig. 32*a* by the method referred to in the second note.

8. Suppose both ends of the modified French struss in Fig. 33*a* are anchored, and that the substituted bar Y Z lies across the spaces V and W; find the reactions and stress (1) neglecting wind pressure, (2) when wind pressure is taken into account.

9. Find the stresses in the bowstring truss, shown in Fig. 36*a*, when both the ends are anchored (1) without wind pressure, (2) when wind pressure is taken into account.

10. The following figures give the Frame and Stress Diagrams for a French Truss. Verify the Stress Diagram and redraw it in the manner explained in the text.

11. Draw the Stress Diagram when there is a wind pressure of 4 tons on the left-hand slope, assuming both sides of the roof to be fixed to the walls.

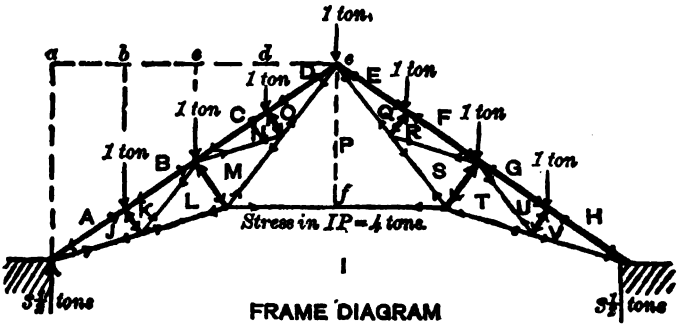

FRAME DIAGRAM

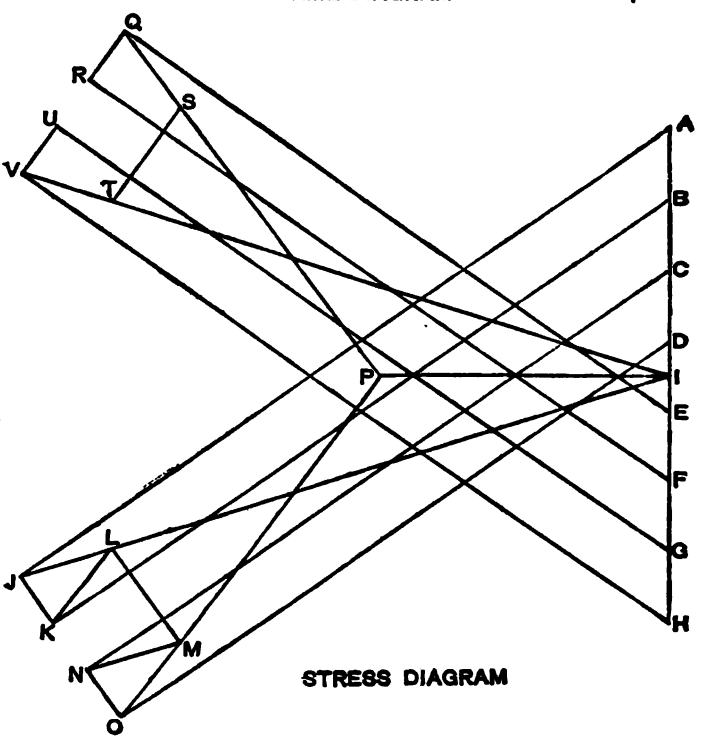

STRESS DIAGRAM

ILLUSTRATIONS FOR QUESTIONS 10 AND 11.

LECTURE XXVI.

CONTENTS.—Deficient Frames—Iron King Post Truss—Queen Post Frame—Solution of the Second Method—Solution of the Third Method—Solution of the Fifth Method—Yieldingness—Questions.

Deficient Frames.—Iron King Post Truss.—In practice the foot of the king rod N O is made virtually solid, as shown by the full lines in Fig. 37*a*. If the short bars N A and O A are made freely

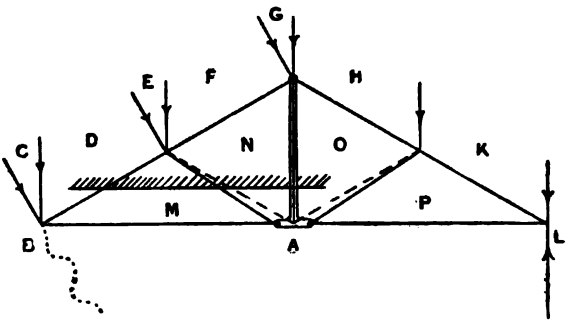

FIG. 37*a*.—FRAME DIAGRAM FOR DEFICIENT KING POST TRUSS.

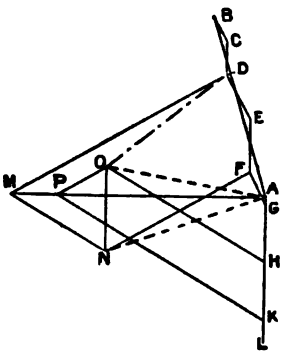

FIG. 37*b*.—STRESS DIAGRAM FOR DEFICIENT KING POST TRUSS.

jointed at N O A, it will be evident that the spaces N and O would change their shape if the loads at the centre of the rafters were unequal. This change of shape is resisted by making the joint N O A rigid.

Since the bars N A and O A are very short compared with the other members, we can draw the Stress Diagram as if the frame were made as shown by the dotted lines in Fig. 37*a*. The full lines in Fig. 37*b*, which is the Stress Diagram of Fig. 37*a*, are drawn on the above assumption.

If a line of section be drawn, beginning in one space of a Frame Diagram and ending in another, so as to pass through a joint or cross two or more bars, then the line joining the points in the Stress Diagram named after the beginning and end spaces gives the resultant of the stresses in all the bars meeting in or crossing that line.

The student can easily verify this by referring to the Stress Diagram.

In Fig. 37*a* a shaded line is shown beginning in the space D and ending in the space O. Then in Fig. 37*b* the chain dotted line D O is parallel to the line of action of the resultant of the stresses in the bars D M, M N, and N O. The length of the line D O gives the magnitude, and from D to O the way of the resultant with respect to the top side of this section. A point in the line of action of this resultant may be found by drawing a line through the joint D E F N M parallel to the line joining D with N in the stress diagram to cut the bar N O produced. The line D N is the resultant of the stresses D M and M N, which must pass through the joint D E F N M. The dotted line O A gives the resultant of the stress actions in the bars O P and P A on the imaginary joint N O A. Therefore, since the bar O A is very short, the force acting on the pin at the end of this bar will be approximately represented by the elements found from the line O A. Similarly, the dotted line N A gives the elements of the force acting at the end of the short bar N A.

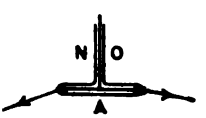

FIG. 38.—FOOT OF KING ROD.

The forces acting at the foot of the King Rod are represented by Fig. 38. These forces produce bending and tension in the parts O A, A N, and N O.

Queen Post Frame.—A Queen Post Frame is represented in its normal position by the solid lines in Fig. 39. If the frame be

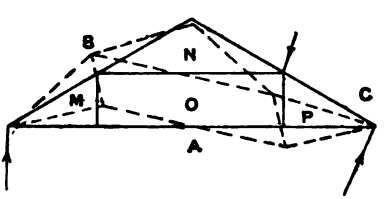

FIG. 39.—DISTORTION OF A FREELY JOINTED QUEEN POST FRAME.

freely jointed, it would be deformed into the shape represented by the dotted lines by a single force B C applied as shown at the joint N B C P O.

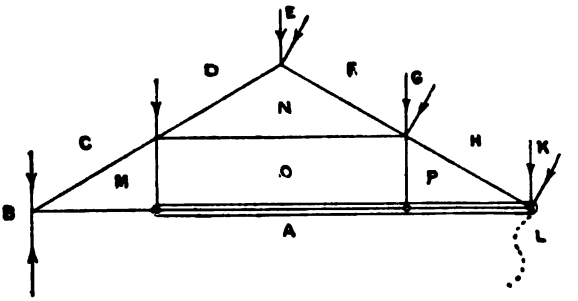

FIG. 40a.—FRAME DIAGRAM.

QUEEN POST FRAME, WITH PART OF TIE-ROD MADE CONTINUOUS.

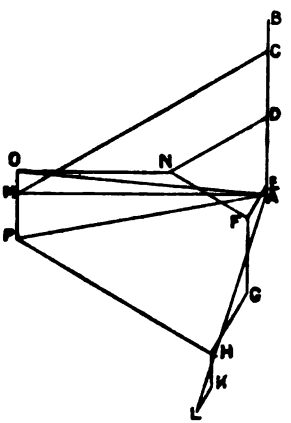

FIG. 40b.—STRESS DIAGRAM.

This change of shape may be resisted in several ways, such as the following :—

(1) By a diagonal in the central parallelogram. This diagonal would have to stand push if the wind caught the frame on one rafter, and pull if the wind pressure were on the other; or the stresses might be due to snow. It is the usual practice to put two diagonal ties in the parallelogram, so that when a push comes on one diagonal the other receives it as a pull. In drawing the Stress Diagram for such a frame, if a push comes on one of the ties, we omit that bar and take the other.

(2) By making the bar continuous between the joints M O A and P C A, and therefore able to resist being bent into the dotted form shown in Fig. 39.

(3) By making the whole tie-beam continuous. This causes the frame to become redundant; *i.e.*, it may be self stressed, by having the bars M O and O P of unequal length, or badly fitted.
(4) By making one rafter continuous.
(5) By making the rafters and tie-beam continuous. This is the usual form in actual practice and causes the frame to become redundant.

Solution of the Second Method.—The reactions are ascertained by a Substituted Frame as already explained. In the Stress Diagram, Fig. 40*b*, we begin by drawing D N and F N; C M and A M; N O and M O; O P and H P all parallel to their respective bars. Then P and O joined with A give the finishing lines of the Stress Diagram. The lines A P and A O are not parallel to the bars A P and A O. This indicates that there is bending in the continuous part of the tie-rod.

In Fig. 41, the forces are shown acting on the part of the tie-beam which is continuous. The vertical components of the forces A O and A P produce bending in the bar, while the horizontal components produce tension.

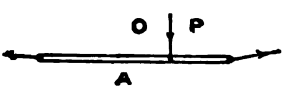

FIG. 41.—THE CONTINUOUS PART OF TIE-BEAM.

Solution of the Third Method.—Having found the reactions and drawn the External Force Polygon, as in Fig. 42*b*, we can then find the point N. We observe that O must lie on the line N O, which is drawn parallel to the bar N O; M must lie on the line D M drawn parallel to the bar D M, and P on the line K P drawn parallel to the bar K P.

On reference to Fig. 39 we see, that so long as the rafter ends always remain in the same horizontal line, the joint O P A must go down as much below the horizontal line as the joint M O A goes above it. Therefore, if the tie-beam is equally rigid along its length, the push required to distort it at the joint O P A must be equal to the pull distorting it at the joint M O A—that is, O P must be equal in length to M O in the Stress Diagram, Fig. 42*b*. If the tie-beam be unequally rigid, then the push and pull will be in proportion to the rigidity at the joints O P A and M O A in Fig. 39. In Fig. 42*a* the distorting force is on the left-hand rafter, and therefore the joint M O A will go down; consequently M O is subjected to push stress.

We can now proceed with the Stress Diagram in Fig. 42*b*.

Since M O is equal in length to O P, P and M must lie where the line D M intersects the line K P. Again, O P and M O are parallel to the bars O P and M O respectively, and N O is

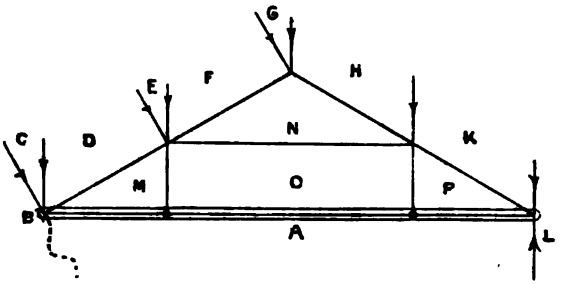

FIG. 42*a*.—FRAME DIAGRAM.

QUEEN POST FRAME, WITH CONTINUOUS TIE-BEAM.

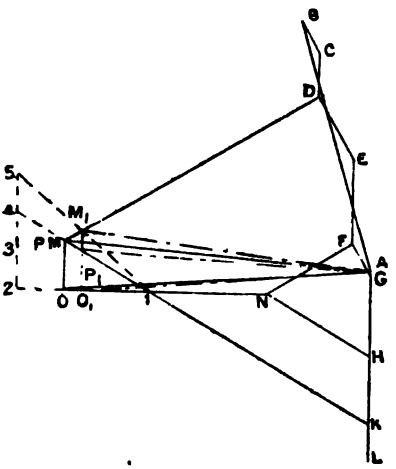

FIG. 42*b*.—STRESS DIAGRAM.

parallel to the bar N O. This fixes the point O. Joining the point P M and the point O with A we complete the stress diagram.

The forces acting on the tie-beam are illustrated by Fig. 43. The force O P and the vertical component of P A constitute a couple tending to produce clockwise rotation. The force M O and the vertical component of A M form another couple of equal moment, and also produce clockwise rotation. These two couples bend the beam, as indicated in Fig. 39. The horizontal components of the forces A M and P A produce tension in the tie-beam.

Now, suppose the rigidity of the tie-beam at the joint P O A to be $\frac{2}{3}$ of its rigidity at the joint M O A, then $O_1 P_1$ must equal $\frac{2}{3}$ of $O_1 M_1$. We must remember that the joint O P A is always as

much above as M O A is below the horizontal line. A construction to determine M_1, P_1, and O_1 is shown by the dotted lines in Fig. 42*b*. The point 2 is taken anywhere in the line N O. The line 2—5 is drawn perpendicular to line N O, and the line K P is produced to cut the line 2—5 in the point 4. Then the length 2—4 must be to the length 2—5 as the rigidities at the joints. In other words, the line 2—5 is three when 2—4 is two, and therefore 4—5 is equal in length to half of 2—4. Now join point 5 with point 1. This line cuts the line D M in the point M_1, and by drawing M_1 O_1 parallel to the bar M O, and N O_1 parallel to the bar N O, we obtain the point O_1.

The finishing lines of the Stress Diagram, Fig. 42*b*, are obtained by joining M_1, P_1, and O_1 with the point A, and are shown by the chain dotted lines.

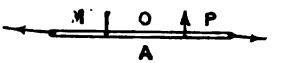

FIG. 43.—FORCES ACTING ON CONTINUOUS TIE-BEAM.

Solution of the Fifth Method.—In this arrangement of bars (Fig. 43*a*) if the joint F G H P O N descends through a small distance (say 1 inch) then the joint O P A of the tie-beam will descend 1 inch, the joint A M O will go up 1 inch and the joint M C D N O will rise 1 inch. Now, all this will take place irrespective of the rafters and tie-beam being of equal or of unequal yieldingness.

Yieldingness.—Two springs are of equal yieldingness, when they stretch through the same amount under equal loads.

One spring would have a yieldingness of three times another, if the first extended three times the amount that the second stretched under the same load.

Further, if two springs of equal yieldingness are attached to the same load, so that they each extend through the same amount; then each spring will carry one half of that load. But, if two springs of unequal yieldingness are attached to the same load, so that they each extend through the same amount; they will each carry a share of the load *inversely* proportional to their yieldingness. Suppose we have two springs, the first one stretches say 1 inch under a load of 3 lbs., while the second one extends 1 inch under 1 lb.; then, if these two springs are set to carry a load of 4 lbs., they will each extend 1 inch and the first spring will carry 3 out of the 4 lbs., while the second will carry the remaining 1 lb.

The above remarks apply equally to bars supporting a load between them, whether they are under a similar kind of stress or not. For example, suppose a beam is jointed to a rod attached

to a rigid point above it; then, their yieldingness would be measured by the amounts they would each come down under

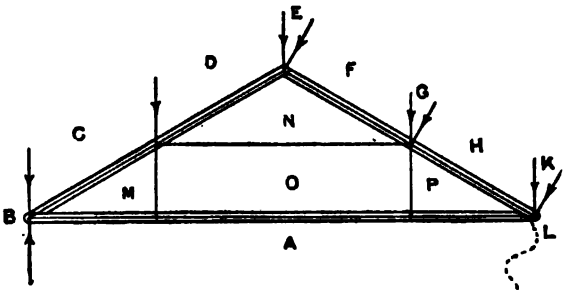

FIG. 43*a*.—FRAME DIAGRAM.

QUEEN POST FRAME, WITH RAFTERS AND TIE-BEAM CONTINUOUS.

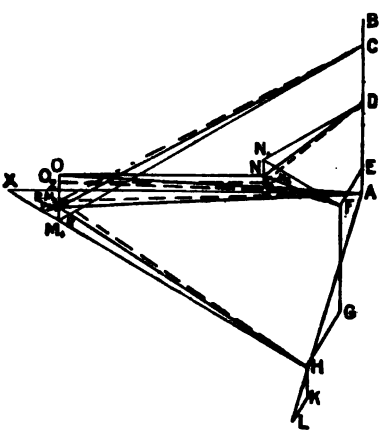

FIG. 43*b*.—STRESS DIAGRAM.

the same load, as applied to each separately at the point where they are jointed to each other.

Referring to the Frame Diagram, Fig. 43*a*, we shall assume in the first place, that the yieldingness of the rafter at the centre in a vertical direction, is the same as the yieldingness of the tie-beam at the joint O P A, also in a vertical direction.* Therefore, whatever is the amount of the vertical component of the distorting force, they will each be subjected to the same stress.

Before we can do anything to the Stress Diagram, Fig. 43*b*, we must first find what amount of the distorting force passes into M O and O P in Fig. 43*a*, on the assumption that the rafters are freely jointed at their centres.

Figs. 44*a* and 44*b* show how this is done. In the Frame Diagram, the force Q G is the difference between the loads C D

* This does not mean that the rafter and the beam have equal rigidity.

and F G in Fig. 43*a*, and G H is the same as in that figure. Now draw the Stress Diagram, Fig. 44*b*, in a similar manner to Fig. 42*b*. That is, Q G and G H are drawn to the same scale as the line of loads in Fig. 43*b*, when T will coincide with Q Draw T U parallel to the bar T U, Q S to Q S and H V to H V. The pull S U is equal to the push U V; therefore S and V are at the intersection of Q S and H V. Then S U drawn parallel to the bar S U completes the Stress Diagram, Fig. 44*b*.

The lengths of S U and U V, give the stresses in the Queen Rods S U and U V, on the assumption that the yieldingness of the rafters is infinitely large. But, the rafters have the same yieldingness as the tie-beam and therefore only half of the distorting forces will pass to the tie-beam. This means, that the pull in the Queen Rod M O and the push in the Queen Rod O P, are equal to one-half of S U and U V respectively.

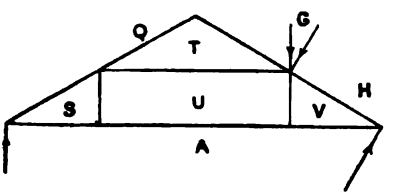

FIG. 44*a*.—FRAME DIAGRAM.

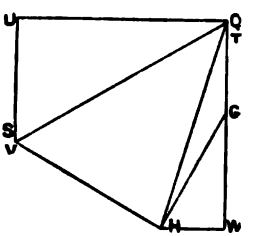

FIG. 44*b*.—STRESS DIAGRAM.

FRAME CARRYING DISTORTING FORCES ONLY.

In the Stress Diagram, Fig. 43*b*, H P_1 and C M_1, are drawn parallel to H P and C M of Fig. 43*a* until they intersect. M_1O is drawn parallel to M O and A X is a horizontal line through A. On the line M_1O mark off two points O and M, where O is as much above A X as M is below it and the distance M O is equal to one-half of S U. This fixes the points M, O and P of the Stress Diagram, because P coincides with M.

Now, draw D N_1 and F N_1 parallel to the bars D N and F N until they intersect at N_1. Through N_1 draw N_1N parallel to M_1O. Then draw O N parallel to the bar O N, and we shall have found all the points in the Stress Diagram, Fig. 43*b*. On joining C with M; H with P; D with N; F with N; O with A; M with A; and P with A we finish the Stress Diagram. The dotted lines represent the Stress Diagram when the yieldingness of the rafters is less than that of the tie-beam.

Divide S U into two parts, having the ratio to each other that the yieldingness of the rafter bears to the yieldingness of

the tie-beam. Then $O_2 M_2$ will have the smaller length as its value, if the yieldingness of the rafter is the smaller; and $O_2 M_2$ will have the larger length of S U if the yieldingness of the tie-beam is the smaller. For example, let the tie-beam be twice as yielding as the rafter. Then divide S U in the proportion of 2 to 1—*i.e.*, into three equal parts—and make $O_2 M_2$ equal to one of the three parts; keeping in mind, that O_2 is as much above A X as M_2 is below it.

LECTURE XXVI.—QUESTIONS.

1. Explain and prove the rule for obtaining the resultant of the stresses in all the bars of a frame crossing any given section. In Fig. 37*a* what is the resultant of the stresses in the bars A P, P K, and also in the bars A M, M N, and N F?

2. The dimensions of an iron king post truss for a roof are:—Span, 20 feet; height, 7 feet; distance between trusses, 8 feet. The roof weighs 12 lbs. per square foot. Find the stresses in each part.

3. In the above question find the stresses when the wind causes a pressure of 30 lbs. per square foot on one slope.

4. Explain the differences caused in the stresses by the different methods of completing a queen post frame. Mention some of the advantages and disadvantages of each.

5. A queen post roof has a span of 30 feet, and is 10 feet high. The roof weighs 10 lbs. per square foot, and the principals are 10 feet apart. Find the several stresses if the rafters and tie-beam are continuous.

6. If there is a wind pressure of 25 lbs. per square foot on the roof in Question 5, find the stresses in the bars.

LECTURE XXVII.

CONTENTS.—Wharf Crane—Example I.—Common Jib Crane—Balanced Jib Crane—Derrick or Scotch Crane—Foundry Crane—Sheer Legs—Example II.—130-Ton Steam Crane—Tables of Dimensions and Weights of 130-Ton Crane—Example III.—Questions.

Wharf Crane.—Suppose, as in Fig. 1*a*, that a single movable pulley carries the load W. Then, neglecting friction, the pull throughout the chain will be one half of W. Again, assume that the pull of the chain acts at the centre of the pulley or barrel round which it may be passing. In the Frame Diagram, Fig. 1*a*, the external forces acting on the frame are all duly indicated. At the Jib end, there are two forces—viz., the pull of gravity D E, on the supported mass, acting vertically downwards and the force C D, due to the pull in the chain which is assumed to be parallel to the tie-rod C H. At the top end of the vertical post, there are the forces B C and A B acting as shown, which are both due to the pull in the chain on the pulley at the post head. There is also a force acting at the centre of the barrel along the crane

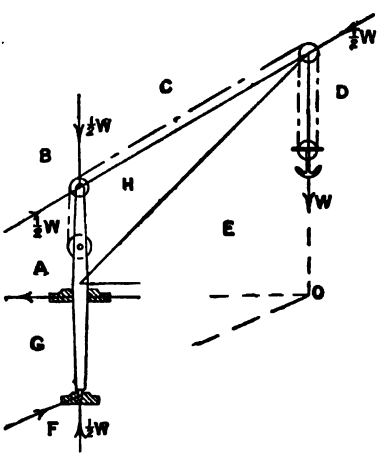

FIG. 1*a*.—FRAME DIAGRAM.

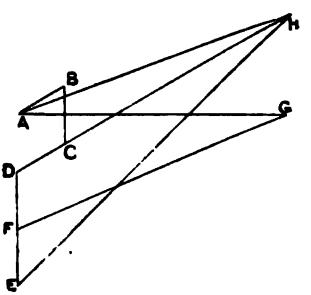

FIG. 1*b*.—STRESS DIAGRAM.

WHARF CRANE.

post. This force must be transferred to the footstep as shown and is called E F in the diagram. There is also a pressure transmitted by the sole plate to the vertical post. This pressure is

assumed to have its line of action horizontal and is lettered G A. Finally, we have the action of the footstep on the lower end of the vertical post.

The three forces D E, F G and G A, must form a system in equilibrium. Therefore, since the lines of action of D E and G A are known, if we produce them to meet in O, then the line of action of F G is known because it must also pass through O.

The Stress Diagram, Fig. 1*b*, may now be drawn. Draw the line of loads A B, B C, C D, D E, and E F. Now, draw F G parallel to the line of action of the force F G and A G parallel to the line of action of the force A G. These close the External Force Polygon. Then if C H and E H be drawn parallel to the bars C H and E H respectively they fix the point H. The line joining the point A with the point H is the finishing line of the Stress Diagram. This line is not parallel to the bar A H because the bar A H is subject to bending.

In Fig. 2, we have a representation of the forces acting on the vertical post; from which, we can determine the bending, tension, and compression stresses in the crane post.

The lengths of the lines C H and E H in the Stress Diagram, Fig. 1*b*, give the stresses in the tie-rod and jib respectively. The horizontal component of G F gives the shear on the bolts of the footstep and G A the shear on the bolts of the sole plate.

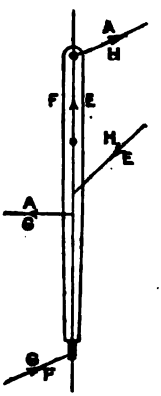

FIG. 2.—FORCES ACTING ON VERTICAL POST OF CRANE.

EXAMPLE I.—In a wharf crane the post, tie-rod, and jib measure 15, 20, and 30 feet respectively, what would be the nature and amount of the stresses in each of the three members when a load of 7 tons is suspended over the pulley at the jib head, (1) when the lifting chain passes from the pulley to the drum or barrel parallel with the jib, (2) when the drum is placed so that the chain passes from the jib head parallel with the tie-rod? (S. and A. Exam., 1890.)

ANSWER.—First, draw to scale a Frame Diagram A B C, as shown. This will be coincident with the centre lines of the different members of the crane.

Case (1).—Here the lifting chain passes from the pulley at the jib head parallel to the jib, and, neglecting the friction of the pulley, we shall have two equal external forces at the joint C due to the tension in the two parts of the chain.

In order to draw the Stress Diagram, we may first proceed to

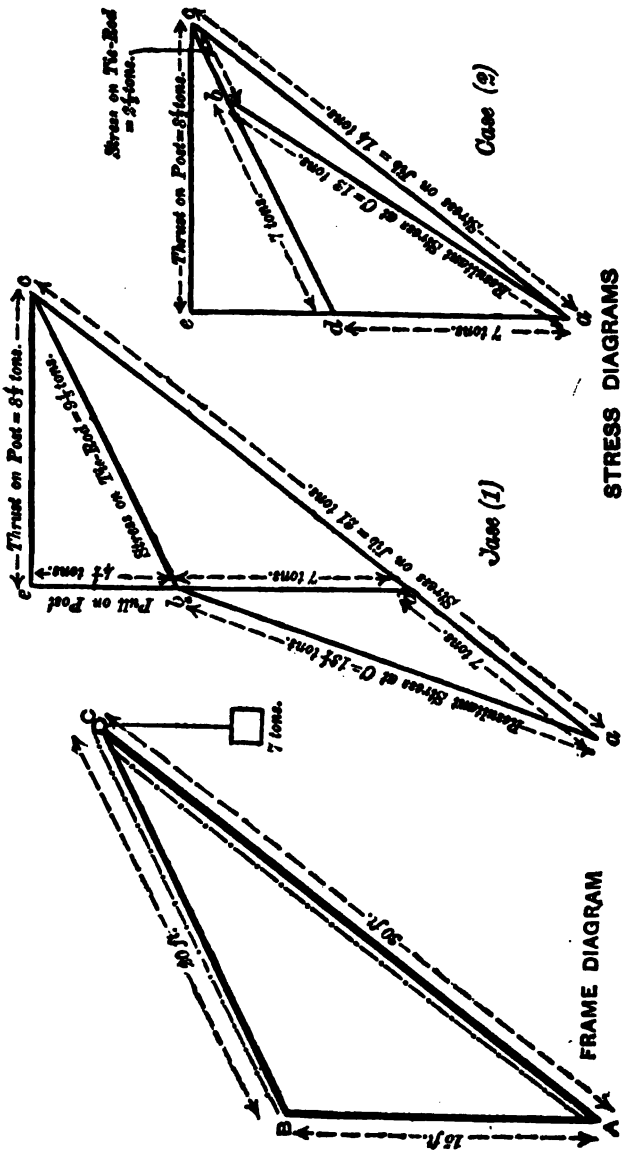

STRESSES IN A JIB CRANE

determine the resultant of these two forces and consider it as a single external force applied to the joint C, and then draw the triangle of forces. Or we may at once draw the polygon of forces for the joint. Thus, draw *b d* to represent the load of 7 tons, and *d a* equal to *b d*, and parallel to C A, to represent the tension in that part of the chain over the pulley; then drawing *a c* and *b c* respectively parallel to A C and B C, we determine the point *c*, and therefore the magnitude of the stresses in the jib and tie-rods. These will evidently be compression and tension respectively. If we join *b a* we obtain the resultant external force at the jib head, and *b a c* will be the triangle of forces determining the same stresses as above.

The nature and amount of the stress in the post will depend on the mode of fixing it. It is evident that the pull *b c* in the tie-rods may be resolved into a vertical component *b e*, producing tension in the post, while the horizontal component *e c* represents the force tending to bend the post round A.

Case (2).—Here the chain passes from the pulley parallel to the tie-rods. We proceed as before, and draw *b d* to represent the pull in the part of the chain above the pulley, and *d a* the pull in the vertical part of it, then *a c* and *b c* drawn parallel to A C and B C respectively, determine the point *c*, and represent the stresses in the jib and tie-rod. Again joining *b a*, we see that this represents the resultant external force at the pulley. The remainder of the diagram is the same as in Case (1).

The magnitudes of the different stresses are shown on the diagrams, and enable us to compare the relative merits of the two arrangements. Thus, if we suppose the load to be suspended from the end of the jib without the intervention of a pulley, we get *b d c* in Case (1), or *d a c* in Case (2) as the corresponding Stress Diagram. The effect of introducing the chain and pulley is in Case (1) to *increase* the thrust in the jib by 7 tons—*i.e.*, the pull in the chain—without affecting the pull in the tie-rods, while in Case (2) the effect is to *diminish* the pull in the tie-rods by the same amount—7 tons—without increasing the thrust in the jib. Thus, other things being equal, Case (2) is the better arrangement.

Common Jib Crane.—In the common Jib Crane represented in Fig. 3, the movable pulley has one sheave, and the chain passes direct to the barrel from the Jib-head. The barrel is carried by the cast-iron framing. There are two tie-rods inclined at an angle θ degrees to the centre line of the crane as shown by the plan of the tie-rods. We assume the cast-iron frame to be freely jointed where the tie-rods and the jib meet it, and also where the horizontal part meets the upright post.

The forces acting on the frame of the crane are indicated in Fig. 4*a*. At the Jib-head there are the two forces W and $\frac{1}{2}$ W. At the point in the bar G H, representing the centre of the barrel, there is a force $\frac{1}{2}$ W, indicated by the dotted line and arrow head. The lines of action of the dotted force and the

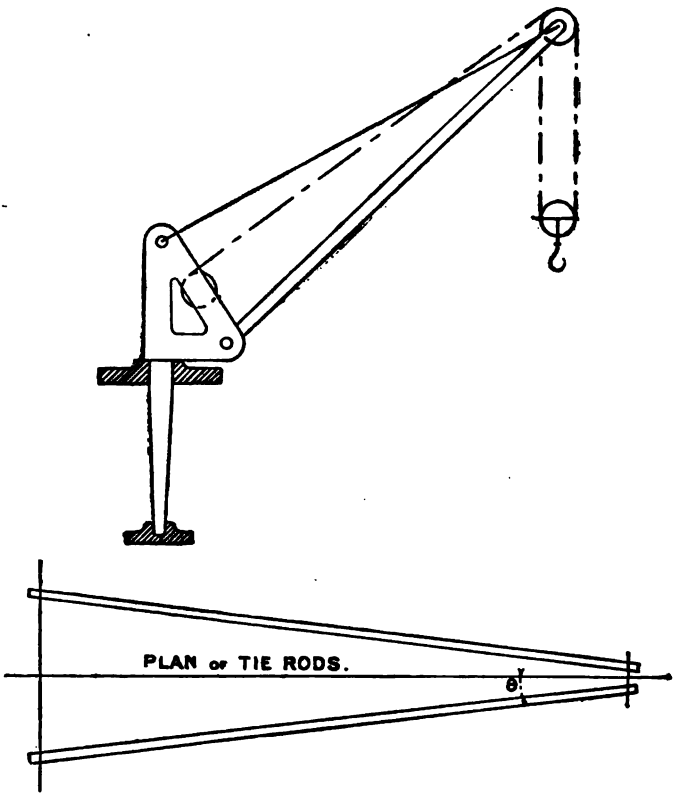

FIG. 3.*—OUTLINE DIAGRAM OF COMMON JIB CRANE.

force B C are coincident. They lie along the line joining the centre of the Jib-head pulley and the chain barrel.

We have here an example of a force acting at a point in a bar. The force acting at a point in the bar G H as represented

* The Plan of the Tie-Rods of this crane has been drawn to a larger scale than the crane itself.

by the chain dotted line, is replaced by the two equivalent parallel forces D E and A B applied as shown. Their magnitudes will be inversely as the lengths into which the bar G H is divided while the sum of their magnitudes is $\frac{1}{2}$ W.

Before beginning the Stress Diagram, we must first determine the values of A B and D E. Lay down a line to measure $\frac{1}{2}$ W and divide this line in the same proportion as the bar G H is divided by the line of action of the dotted force. Then, these two parts will measure to the same scale as the whole line, the respective values of the forces A B and D E. The greater force is placed at the end of the shorter division of G H.

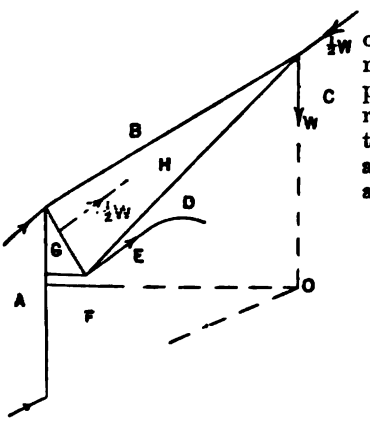

As in the last crane, the pull of gravity C D on the supported mass, the pressure of the sole-plate E F on the upright and the reaction of the footstep F A on the upright, are in equilibrium and therefore their lines of action all pass through one point O.

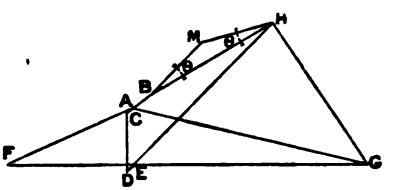

FIG. 4a.—FRAME DIAGRAM. FIG. 4b.—STRESS DIAGRAM.
COMMON JIB CRANE.

The line of action of E F is assumed to be horizontal and the line of action of C D to be vertical. In the Stress Diagram, Fig. 4*b*, we first draw A B, then B C, C D, and D E. This completes the line of loads. Now, from E draw E F parallel to the line of action of the pressure E F; and, from A draw A F parallel to the line of action of the reaction A F. These two lines determine the point F and complete the External Force Polygon. Then, draw B H and D H parallel to the tie-rod B H and the jib D H respectively. These fix the point H. Draw H G and E G parallel to the bars H G and E G. This fixes the point G. On joining C with G the Stress Diagram is completed.

B H in Fig. 4*b* represents the stress on the tie-rod, on the assumption that there is only one tie-rod lying along the centre line of the crane. We require, therefore, to resolve this stress

into two components, one along each tie-rod. This is done in the Stress Diagram by drawing from H and from B lines H M and B M each making an angle with B H of θ degrees. Then the lengths of H M and B M measure to scale the stresses in the tie-rods.

Balanced Jib Crane.—The balance weight B W acting at G, is usually mounted on rollers in order that it may be moved nearer to the central post A when the load W is reduced. In this way the moments of the load and balance weight may be kept in equilibrium and thus prevent any undue bending action on the

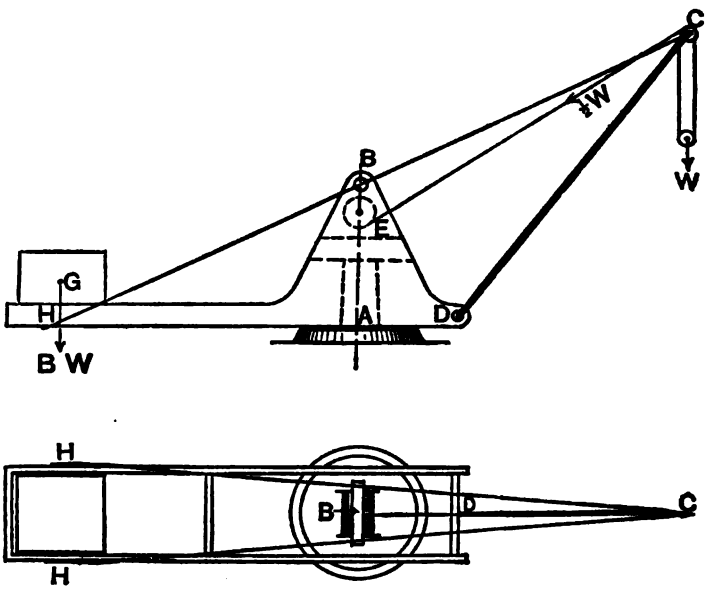

FIG. 5.—BALANCED JIB CRANE.

post at A. We may here remark that the balance weight B W at G and the load W at C are not necessarily equal.

A single movable pulley carries the load W and therefore the tension throughout the chain is $\frac{1}{2}$W. We assume that bars join B with D; D with A; A with B; and A with H. These are all indicated in the Frame Diagram of Fig. 5. The line joining the centre of the pulley C with the centre of the chain barrel E is considered as the line of action of the stress in the chain. From the plan it will be seen that there are two tie-rods

inclined to each other; these rods are often made continuous from C to H.

The load of ½ W acting on the bar F G, Fig. 6*a*, is divided as explained in the previous example into forces B C and K A. If W is known, we can find on completing the Stress Diagram, the magnitude of the balance weight A B required to balance the moment of the load W about the joint F G E K A. Or, if the balance weight be moved nearer the crane post we can find what weight may be placed in the crane hook.

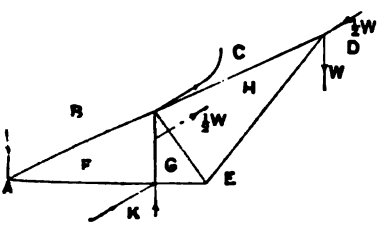

FIG. 6*a*.—FRAME DIAGRAM.

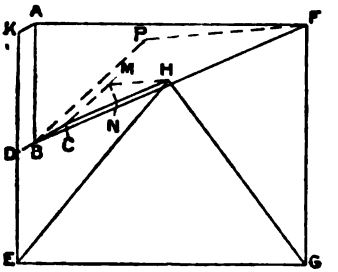

FIG. 6*b*.—STRESS DIAGRAM.

BALANCED JIB CRANE.

We begin the Stress Diagram, Fig 6*b*, with the line B C, then C D, and D E. We next find the point H, then, G, F, A, and finally K.

The actual stress in the tie-rods is found, by drawing H M and C M at an angle with H C, equal to half of the real angle between the tie-rods, as previously explained. From F and B draw F P and B P inclined to F B at half the angle between the parts of the tie-rods carrying the balance weight. If the tie-rods are continuous, then H M and F P are parallel.

Derrick or Scotch Crane.*—In Fig. 7, A B is the central upright post, capable of turning round A and B. B C is the jib and A C the tie-rod, which is usually a chain for raising or lowering the jib. The vertical post A B is kept upright by the back stays A E and A E_1. These stays are sometimes anchored to the ground, but are generally attached to the bars B E and B E_1. Boards are placed over these bars and stones or pig iron are placed thereon to act as counterweight to the load W. This crane is similar to that in Fig. 5, in

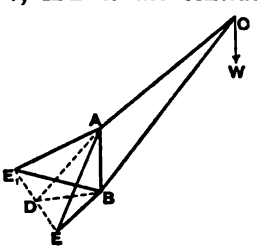

Fig. 7.—DERRICK CRANE.

* See figure at end of this Lecture.

that back balance weights are used. The weights in Fig. 7 are, however, not required to be made movable in order to produce a moment round B equal and opposite to the moment of W round the same point. This is due to the fact, that the under sides of the bars B E and B E_1 rest upon the ground, and, therefore, no matter how much the moments of the balance weights round B may exceed the moment of the load, there is no bending stress produced on the pivot at B.

The chain carrying the load W is usually parallel to the tie-rod A C. It then passes round a pulley at A and down to the barrel on the upright post.

By reference to the Stress Diagrams, Figs. 1*b* and 6*b*, the Stress Diagram for Fig. 7 may be drawn. When the plane of the triangle A B C in Fig. 7, coincides with the plane of the triangle A B E, the stress in A E will be a maximum, the stress in A E_1 will be theoretically zero, and the weight required at E may then be found. Similar considerations will give the stress in A E_1 and the weight required at E_1.

Let the plane of the triangle A B C now occupy any intermediate position between the planes of the triangles A B E and A B E_1. Then the stresses in A E and A E_1, may be found by producing the plane of the triangle A B C to intersect the planes A E_1 E and E_1 B E in A D and B D. Now proceed to find the stress in A D as if D were anchored to the ground, then resolve this stress along the stays A E and A E_1, as explained for the inclined tie-rods of the two previous examples. The angle E_1 B E is usually a right angle.

Foundry Crane.—The Frame Diagram, Fig. 8*a*, illustrates the arrangement of the parts of this type of crane. The pulley carrying the load W is attached to a small bogie running between two parallel horizontal beams. The external forces acting on the crane are F G, G A, A B, C D, E F (each equal to W), B C, and D E. The external force A B balances E F, and C D balances G A, therefore the remaining external forces B C, D E, and F G form a system in equilibrium. Their lines of action will pass through one point O, and their magnitudes may be determined by the triangle of forces. These results may be made use of in drawing the Stress Diagram, Fig. 8*b*. Commence by drawing E F, F G, G A, and A B all equal in magnitude to W, and parallel to their respective lines of action. If we draw B C parallel to the line of action of the force B C, so as to intersect the line through E parallel to the line of action of the forces C D and D E in the point C, then by marking off C D equal to W we complete the external force polygon.

The stress in A H will be unaffected by raising or lowering

either the footstep or the bearing at the top, so long as the line of action of the load and the position of the joints 1, 2, and 3 remain unchanged. Let us suppose that the footstep coincides

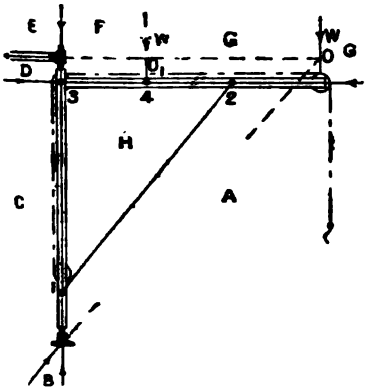

FIG. 8a.—FRAME DIAGRAM.

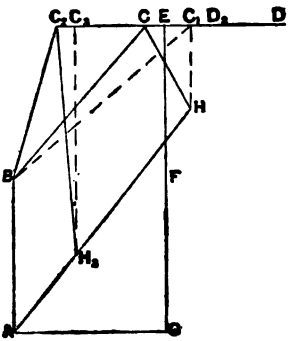

FIG. 8b.—STRESS DIAGRAM.

FOUNDRY CRANE.

with the point 1, and the bearing at the top with the point 3, then the line of action of the stress in C H will be along the

FIG. 9.—FORCES ACTING ON UPRIGHT OF FOUNDRY CRANE.



FIG. 10.—FORCES ACTING ON JIB WITH PULLEY AT POINT 4 ON FIG. 8a.

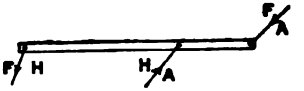

FIG. 11.—FORCES ACTING ON JIB IN FIG. 8a WITH PULLEY AT END OF SAME.

centre line of the bar C H, while the line of action of the footstep reaction B C_1 will pass through the point 1 and the centre of the pulley carrying the load.

In the Stress Diagram, Fig. 8*b*, draw B C_1 through the point B parallel to the line joining the point 1 with the centre of the pulley carrying the load, so as to cut the line C D in the point C_1; then by drawing C_1 H and A H parallel to the bars C H and A H respectively, we determine the point H. Finally, C joined with H finishes the Stress Diagram. When the pulley carrying the load occupies the position represented by the point 4, then C_2, D_2, and H_2 (found in a similar manner) are the corresponding points in the Stress Diagram.

Fig. 9 represents the forces acting on the upright, which



FIG. 12.—RUSSELL'S PATENT SHEER LEGS.

produce bending, tension, and compressive stresses, for the case when the movable pulley is at the end of the horizontal jib.

In Figs. 10 and 11, if the maximum bending moment in each case be the same, then the point 2 in Fig. 8*a* has been so chosen, as to make the bending moment on the horizontal jib have its least value whilst the pulley carrying the load passes from one end of the jib to the other. (See Ques. 41 of Hons. S. & A. Exam. in Machine Constn., 1890.)

Sheer Legs.—A common appliance for lifting engines and boilers into ships is the sheer legs or sheers. The illustration

shows one that has been erected at West Hartlepool by Messrs. George Russell & Co., of Motherwell, for a load of 80 tons overhung 38 feet 6 inches. It consists of two tubular front legs, each 105 feet long, swinging upon pins at their lower ends, and connected together at the top, which is supported by a hollow stay or back leg. This stay is fixed to the gunmetal nut of a forged steel screw, which rotates inside the back leg. The screw is anchored at its lower end, and can be rotated by a hydraulic engine. As the screw revolves one way or the other, the back leg is shortened or lengthened, and the top is moved in or out, as shown on Fig. 13. The total horizontal travel thus given to the load is 50 feet.

Chains worked by a pair of hydraulic engines are used for lifting, and there are separate chains for light and heavy loads. The latter chain operates a six-purchase pulley block.

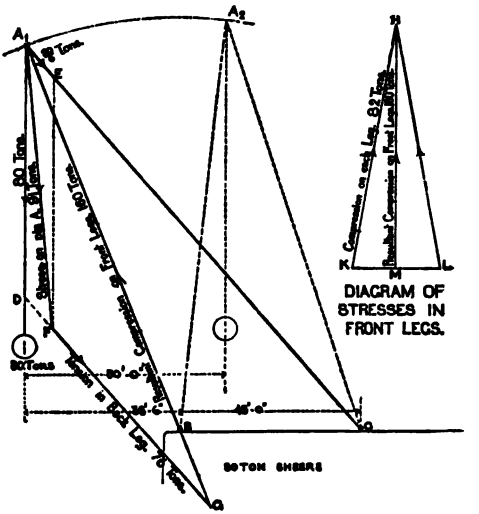

FIG. 13.—COMBINATION OF FRAME AND STRESS DIAGRAMS FOR FIG. 12.

In Fig. 13, A_1 B is the line of the front legs hinged at B, and A_1 C that of the back leg. The top can move between A_1 and A_2 by altering the length of A C. The vertical A_1 D represents the load on the sheers (80 tons), and A_1 E the tension in the chain, ($\frac{1}{6}$ of 80 or $13\frac{1}{3}$-tons since there are six chains supporting the load). Draw E F parallel to A_1 D, and D F parallel to A_1 E. Then A_1 F is the resultant force to be balanced by the stresses in the legs A_1 B, A_1 C. Draw F G parallel to A_1 C, and meeting A_1 B produced, if necessary, in G. Then A_1 G (160 tons) is the compression transmitted to the front legs, and F G (76 tons) the tension in the back leg. As the two front legs are not parallel, we must, in order to determine the actual stress in each, draw a second figure, as shown at the right-hand side. Here H M is equal to half A_1 G, and K H M and L H M are each half the

angle between the front legs. K L being drawn perpendicular to H M, we obtain H K and H L (82 tons) as the compression in each leg.

EXAMPLE II.—The foot of a uniform derrick pole of weight 2 cwts. rests on the ground, and the pole carries a weight of $1\frac{1}{2}$ tons suspended from its upper extremity. The length of the pole is 20 feet, and it is kept in position by a guy rope fastened to the ground 10 feet to the rear of the foot of the pole and 25 feet in length. Find by construction or otherwise the tension of the guy rope.

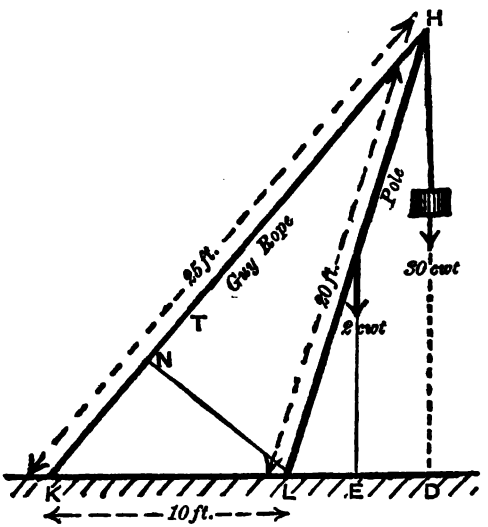

DERRICK POLE.

ANSWER. — In the figure, L H is the derrick and K H the guy rope. The weight of the derrick acts at its centre, and may be replaced by 1 cwt. at each end, so that the total load in the upper end may be taken as 31 cwts. This is the force A B on the Frame Diagram. For the Stress Diagram draw A B parallel to the force A B and equal to 31 units. Make B C parallel to the pole and A C to the guy rope. Then, A C is the tension in the guy rope and is equal to 25 cwts. and B C (= 53 cwts.), the compression in the pole.

This problem could have been solved by the Principle of Moments, as follows:—

Let T be the Tension in the guy rope.
" w " Weight of the pole.
" W " Weight hung from pole.

Drawing L N perpendicular to K H and taking moments about L (in the first figure), we have:—

$$T \times LN = W \times LD + w \times LE$$

Or, $$T = W \times \frac{LD}{LN} + w \times \frac{LE}{LN} = (W + \tfrac{1}{2} w)\frac{LD}{LN}.$$

From Euclid II., 12, we have:—

$$KH^2 = KL^2 + LH^2 + 2\,KL\,.\,LD$$

$$\therefore \quad LD = \frac{KH^2 - KL^2 - LH^2}{2\,KL} = \frac{625 - 100 - 400}{20} = 6{\cdot}25 \text{ ft.}$$

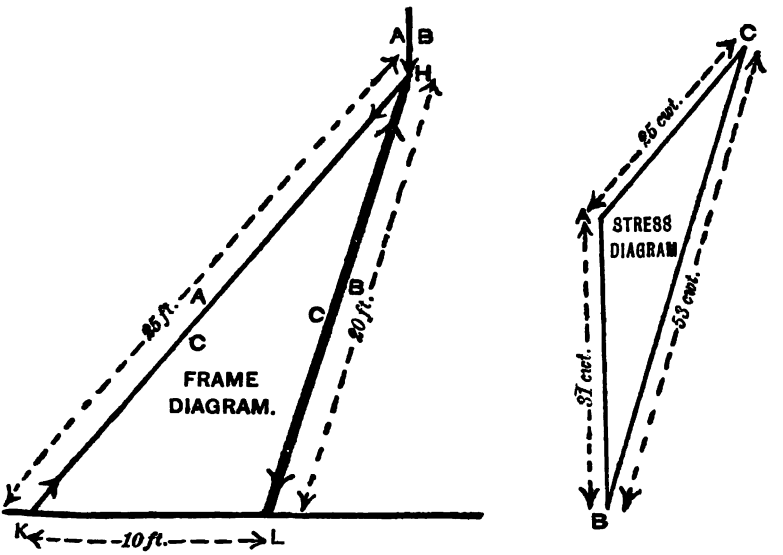

STRESSES IN A DERRICK POLE.

Also, $LN \times KH$ = twice triangle $LKH = HD \times KL$

Or, $$LN \times KH = (\sqrt{LH^2 - LD^2}) \times KL$$

$$\therefore \quad LN = \frac{KL}{KH}\sqrt{LH^2 - LD^2} = \frac{10}{25}\sqrt{400 - 39}$$

Or, $$LN = \frac{2}{5}\sqrt{361} = \frac{38}{5} = 7{\cdot}6 \text{ ft.}$$

Hence, $$T = (30 + 1)\frac{6{\cdot}25}{7{\cdot}6} = \frac{31 \times 6{\cdot}25}{7{\cdot}6} = 25{\cdot}5 \text{ cwts.}$$

130-Ton Steam Crane* (*see Frontispiece*).—As an example of a very large crane, we have illustrated in the frontispiece to this volume the 130-ton steam crane erected for the Clyde Trustees at Finnieston Quay, Glasgow, by Messrs. Cowans, Sheldon, & Co., Limited, of Carlisle. A similar crane has also been put up at the new Cessnock Dock, Glasgow. The jib of this crane is made up of two steel tubular girders braced together by diagonal and cross stays. The tension rods have been sawn out of solid steel plates, and were not heated during their manufacture. They are connected to the jib by stays at intervals along their length. The foot of the jib is attached to one of the bottom corners of a large vertical triangular frame, and the tension rods to the upper corner, while the back one supports the balance weight which is placed between the two sides of the main framing. The boilers and engines are also placed within this framing, which is covered in so as to form an engine-house. The whole is fixed on the top of a circular base, which can rotate around a large central pin, and rests on steel rollers running on a steel pathway on the top of the foundation. There is also a roller bearing between the base and top of the centre-pin. The foundation, which is square in plan, is of concrete with granite corners and cope, and is supported on twenty-two concrete cylinders sunk into the sand. The centre piece of the crane is fixed to the foundation by six steel bolts cottered to washer plates in a tunnel inside the foundation.

There are two separate lifting blocks, the one for heavy, and the other for light weights. Each of these can be raised or lowered at two different speeds. Separate engines are provided for each of these blocks, and for rotating the crane. All three sets of engines have two cylinders with cranks at right angles, so as to start from any position. Steel wire ropes are used for hoisting instead of chains. The heavy weights are taken on an eight-purchase pulley block, and the light weights on a double-purchase pulley block. All the gearing, up to 24 inches diameter, is of cast steel, and the remainder of a mixture of cast-iron and steel. Gun-metal bushes are used throughout.

The crane is provided with a 160-ton Duckham hydrostatic weighing machine, and was tested by loading it with 150 tons of steel rails. Its radius of action is 65 feet, and the total lift is 100 feet.

The following tables show some of the leading dimensions and weights:—

* For a complete description of this crane see *Engineering*, June 9, 1893.

PARTICULARS OF 130-TON CRANE AT FINNIESTON QUAY, GLASGOW.

Part.	Number.	Length.	Breadth.	Diameter.	Thickness or Height.	Height above or below Quay.	Total Weight in Tons.	Projects beyond Cope of Quay Wall.
Foundation above front cylinders,	...	40′ 0″	40′ 0″	...	45′ 0″	Top 20′ up	4,300	5′ 6″
Foundation, Concrete cylinders,	22	36′ 6″	...	9′ 7½″ and 5′ 9½″	...	...	...	...
Tunnel and Passage,	...	...	2′ 0″	Centre 10′ 9″	6′ 0″	Top 10′ down.	...	...
Foundation bolts,	6	38′ 9″	...	0′ 5″	...	...	8	...
Washer Plates,	6	6′ 0″	6′ 0″	..	...	10′ down.	13	...
Centre Piece for Crane,	...	...	...	...	...	...	9	...
Centre Pin,	...	...	...	0′ 17″	...	...	6	...
Roller Path,	...	...	...	33′ 0″	...	...	12	...
Rollers,	75	...	...	0′ 14″	...	...	10·5	...
Framing,	...	...	...	...	27′ 0″	...	50	...
Boiler,	...	...	...	6′ 0″	14′ 0″	...	6	...
Back Balance,	...	...	...	...	...	...	100	...
Jib,	...	90′ 0″	...	Tubes 3′ 3″ at centre to 2′ 6″ at ends.	7/16″ at centre to ½″ at ends.	Top 110′ up.	45	...
Single Tension Rods,	...	...	0′ 10″	...	0′ 2¾″	...	15	...
Double ,,	...	...	0′ 10″	...	0′ 1½″	...		
Pins for ,,	...	...	...	0′ 8″	...	...		
Pulley for light weights,	...	...	...	2′ 6″	...	107′ 6″	...	41′ 3″
Pulley for heavy weights,	...	...	...	5′ 3″	...	100′ 0″	...	39′ 6″
Gin block for light weights,	...	...	...	...	...	...	...	44′ 3″
Gin block for heavy weights,	4 pulleys	12′ 0″	7′ 0″	Pulleys 5′ 3″	3′ 0″	...	7	39′ 6″
Hoisting Drum for light weights,	...	...	...	2′ 6″	...	...	...	...
Hoisting Drum for heavy weights,	...	10′ 0″	...	5′ 2″	...	...	10·5	...
Gearing,	...	...	...	...	...	...	8	...
All Castings,	...	...	...	...	...	...	120	...
Crane in working order, exclusive of back balance,	...	...	...	...	...	...	270	...
Radius of sweep for light loads,	...	69′ 9″	...	...	...	...	...	...
Radius of sweep for heavy loads,	...	65′ 0″	...	...	...	...	...	...

Particulars of Engines for 130-Ton Crane.

For Load.	Engines.			Distance Raised in One Minute.	Time to make Complete Revolution of Crane.
	No. of Cylinders.	Diameter.	Stroke.		
130 tons, . .	2	12″	16″	4′	5 mins.
60 ,, . .				8′ 10½″	2 mins. 17 secs.
20 ,, . .	2	8″	12″	28′	...
8 ,, . .				60′	...
Revolving, . .	2	8″	12″	...	...

Particulars of Steel-Wire Ropes for 130-Ton Crane.

Rope.	Inner Core.		Second Layer.		Third Layer.		Outer Layer.		Total No. of Wires in each Strand.	No. of Strands.	Total No. of Wires.	Remarks.
	No. of Wires.	Diam. of Wires.	No. of Wires.	Diam. of Wires.	No. of Wires	Diam. of Wires.	No. of Wires.	Diam of Wires.				
Heavy Lifts, .	3	·078″	9	·084″	15	·084″	18	·101″	45	7	315	Six strands are of patent steel, and are wound round a central strand of soft steel.
Light Lifts, .	1	·060″	6	·060″	12	·060″	18	·000″	37	7	259	

The factors of safety allowed in the different parts are :—

Main framing, jib, tension rods, &c., ...	6
Wire ropes, ...	8
Centre holding down bolts, to allow for rusting, .	12

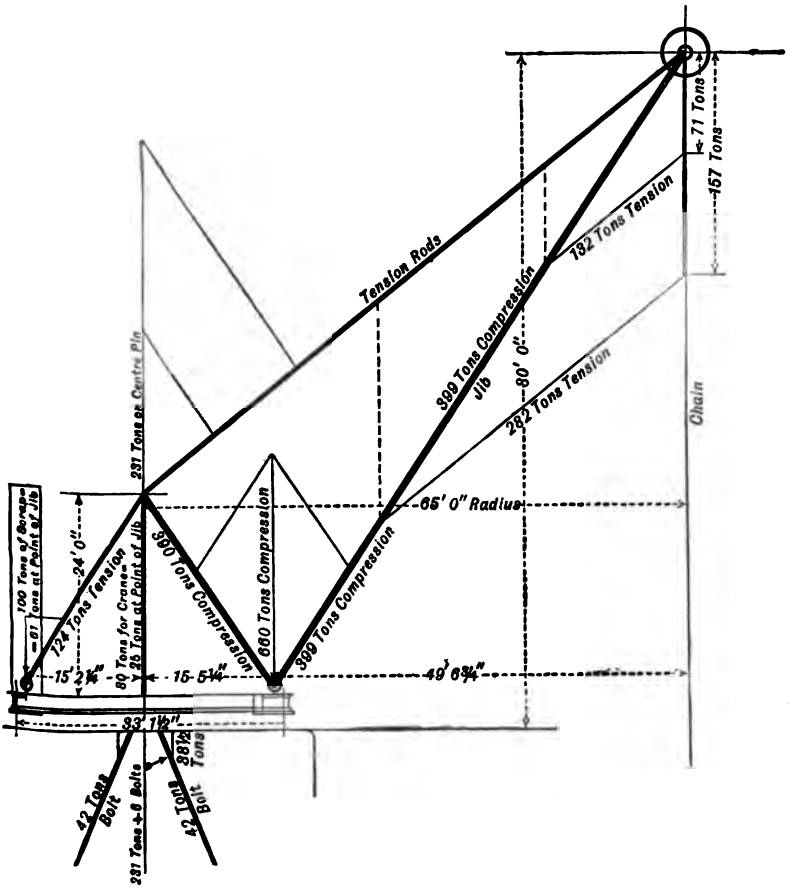

FIG. 14.—STRESS DIAGRAM FOR 130-TON CRANE. (TEST LOAD, 150 TONS.)

The accompanying figures show the Stress Diagram for the crane when loaded with 150 tons, or, including the weight of the gin block, 157 tons in all, and also for a gross load of 71 tons.

Fig. 14 is the Stress Diagram as worked out by the makers. Fig. 15*a* represents the Frame Diagram and Fig. 15*b* the Stress Diagram worked out for the Test Load as we have treated the previous cranes—viz., all in one figure.

First, find the values of the Forces D E and A B in Fig. 15*a* as already explained. Then begin the Stress Diagram with the force A B and follow with the forces B C, C D, D E, E F and F G. Now E L and G L fix the point L; B H and C H the point H; H K and L K the point K; K N and G N the point N; and N M and A M the point M.

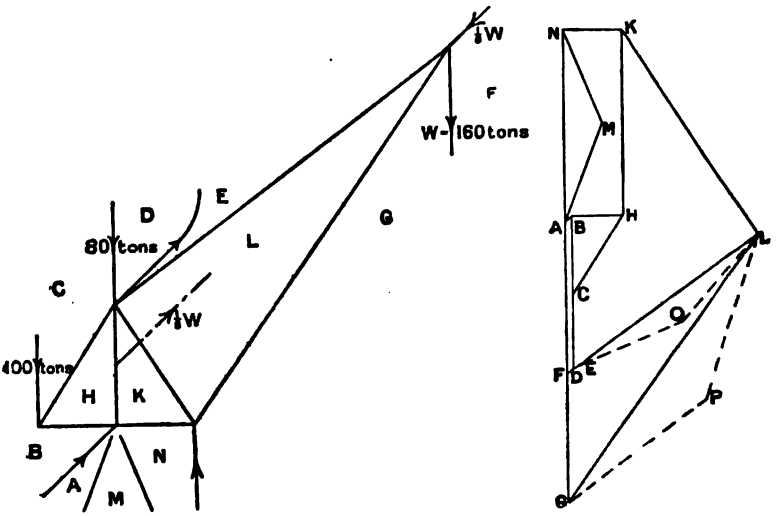

FIG. 15*a*.—FRAME DIAGRAM. FIG. 15*b*.—STRESS DIAGRAM.

130-TON CRANE WORKED OUT AS IN THE PREVIOUS EXAMPLES.

The stress E L is borne by the two tie-rods and L O and E O represent the stresses in each tie-rod. The stress G L is divided over the two jibs, consequently L P and G P represent the stresses in each jib, as already explained.

The stress A M is divided over half of the holding down bolts and N M over the other half. The point about which the crane tends to topple over is the joint K L G N.

EXAMPLE III.—A tripod whose vertex is A, and whose legs are A B, A C, A D, of lengths 8, 9, and 10 feet respectively, sustains a load of 2 tons. The ends B, C, D form a triangle, whose sides are B C = 7 feet, C D = 6 feet, B D = 8 feet, find

by graphical construction the compressive stress in each leg. (S. and A. Exam., 1889.)

ANSWER.—Hitherto we have dealt only with forces in one plane, or symmetrical with respect to one plane. Thus, in the case of the sheer legs, in determining the compression on the front legs, we first found what would be the compression on an intermediate leg in the same plane as the two replaced, and equally inclined to both. This hypothetical leg would be in a vertical plane containing the back leg and the externally applied force, and evidently the stress in the back leg would not be affected by the substitution. In the present example we must find the

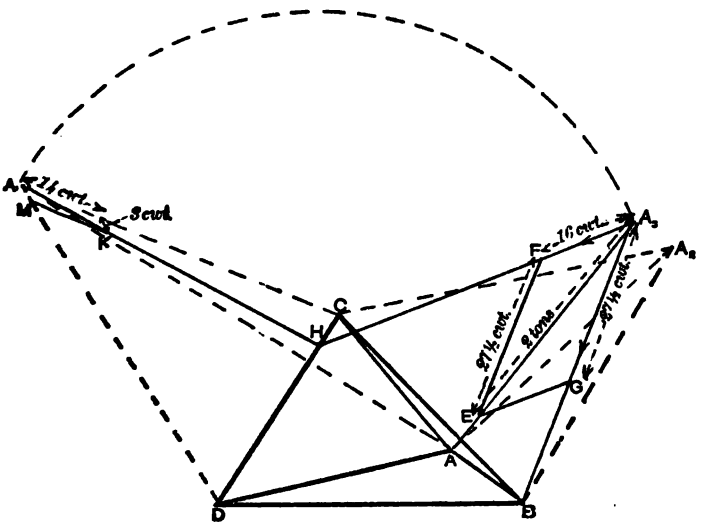

STRESSES IN A TRIPOD.

corresponding intermediate leg, so that if the load be supported by it and the third leg, the stress in the latter will not be altered. It will be in a vertical plane containing the third leg, and will be represented by the line of intersection of this plane with that of the other two legs, hence the following solution :—Draw B C D the triangle formed by the feet of the tripod; to find the plan of the vertex, draw the triangle D C A_1, making C A_1 and D A_1 equal to C A and D A respectively. Similarly, draw the triangle A_2 C B; then A_1 A drawn perpendicular to C D, and A_2 A drawn perpendicular to C B, will give by their

intersection the plan of the vertex A, and we may now complete the plan. The vertical plane containing the leg A B will cut the line D C in a point H lying on the line B A produced;



TRIPOD FOR LAYING PIPES.

then $A_1 H$ will be the length of the required intermediate leg. Draw $A A_3$ at right angles to B A H, and make $H A_3 = H A_1$. Thus we get $A_3 H$, $A_3 B$, and the applied force $A_3 E$ in one

plane. The stress in the leg A B will be represented by A_3 G, and the resultant stress in the legs A C and A D—*i.e.*, the stress in the hypothetical leg A H by A F. Dividing this between the actual legs by the triangle of forces A_1 M K, where A_1 K = A F, we get the stress in A C represented by A_1 K, and that in A D by A_1 M. The respective values are marked on the diagram.

As a practical example of the use of a tripod, we illustrate a form much used—in laying water and other mains—for lowering large pipes into position. Two of the legs are braced together, and carry a winch which may be used in conjunction with a block and tackle. The pipe is rolled on to wooden beams laid across the drain, and the tripod then placed in position over it. The pipe is slightly raised by means of the winch, and the wooden beams removed, when the pipe may be lowered with ease.

We also illustrate a simple hand crane as used by contractors for building, &c. It is of the kind discussed in connection with Fig. 7.

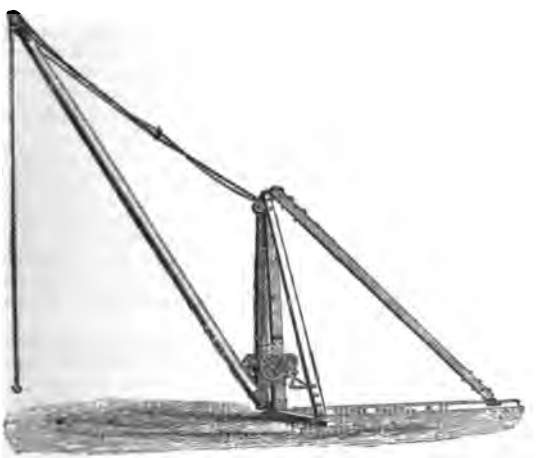

HAND DERRICK CRANE.

LECTURE XXVII.—QUESTIONS.

1. In a model of a crane the jib is 3½ feet long, the tie-rod is 3 feet long, and is fastened to a point 1 foot vertically above the lower end of the jib, What is the thrust on the jib when a weight of 20 lbs. is hung at the upper end of it? *Ans.* 70 lbs.

2. In a wharf crane the post, tie-rod, and jib measure 15, 20, and 30 feet respectively, what would be the nature and amount of the stresses in each of the three members when a load of 7 tons is suspended over the pulley at the jib head, (1) when the lifting chain passes from the pulley to the drum or barrel parallel with the jib, (2) when the drum is placed so that the chain passes from the jib head parallel with the tie-rod? (S. and A. Adv. Exam., 1890.)

3. In a hydraulic wharf crane the height of the post is 6 feet, the jib is 22 feet, and the tie-rod is 18 feet; find the horizontal thrust on the post when 5 tons are supported. In what way is the friction which opposes the *slewing* motion reduced to a minimum? *Ans.* 12·24 tons.

4. Find, either graphically or otherwise, the stresses on the jib and tie-bar respectively of a crane, whose jib measures 20 feet in length, when the tie-bar and post are 16 feet and 6 feet in length respectively, and a weight of 25 cwts. is suspended from the end of the jib. The line of direction of the chain after leaving the barrel or drum runs parallel to the tie-bar. Also calculate the pressure on the end of the handle of 16 inches radius when the weight is lifted, supposing the drum of the crane to be 15 inches in diameter, and the gearing to consist of a pinion of 12 teeth, gearing into a wheel with 72 teeth, while a second pinion of 18 teeth gears with a wheel of 56 teeth. (S. and A. Adv. Exam., 1893.)

5. A contractor's portable hand crane has a vertical post A B, to which the jib A C is inclined at 45°, and the tension rod B C makes with A B an angle A B C of 120°. The back stay from the head of the post B to the extremity D of the horizontal strut A D is inclined at an angle of 45° to A D. Find the weight of the counterbalance required at D to balance a load of 10 tons suspended from the end C of the jib. Determine also the nature and amount of the stress on the jib A C, and in the rods B C and B D? (The tension in the chain may be neglected.) (S. and A. Adv. Exam., 1896.)

6. A jib foundry crane consists of a vertical post A B, 16 feet long, fitted with pins working in sockets at both A and B. From the upper end A of the post extends a horizontal member A D, 28 feet in length, and from the foot B is a strut B C, which meets A D at a point 16 feet from A. A load of 20 tons being suspended from D, find the shearing stress on the pin at A, and the stress along the strut B C. (S. and A. Adv. Exam., 1892.)

7. A sheer-legs is formed of two sheer-poles B C, D C, each 25 feet in length, and secured to a base-plate in the ground at B and D. The wire guy or tension rope A C is attached to the ground at a point A, which is 60 feet distant from B D. The perpendicular from the top C of the poles meets the ground at a distance of 10 feet from the centre of the line B D, which is 15 feet long. Find by measurement or otherwise the tension in tons on the guy when a weight of 20 tons is suspended. (S. and A. Adv. Exam., 1888.) *Ans.* 11·3 tons.

LECTURE XXVIII.

CONTENTS.—Reactions on a Beam—First Method—Resultant of the Loads on a Beam—Reactions on a Beam—Second Method—Fink Truss—Trapezoidal Truss of Three Panels—Trapezoidal Truss of Five Panels—Example I.—Warren Girder—Linville or N Girder—Lattice Girder—Redundant Frame—Five Bay Lattice Girder—Lattice Girder loaded at Top Joints—Bending Moment—Definition—Shearing Force—Definition—Cantilever Uniformly Loaded—Examples II. and III.—Centre of Gravity of an Area—Moment of Inertia of an Area—Proof—Engine Mechanism—Questions.

Reactions on a Beam.—FIRST METHOD.—*First Case.*—In the Frame Diagram, Fig. 1*a*, we have a beam with five concentrated loads upon it. The line of action and point of application of the left-hand reaction, and the point of application of the right-hand reaction are known.

We commence Fig. 1*b* by drawing the line of loads, B C, C D, D E, E F and F G. Then, any point O is taken and joined with all the points in the line of loads as illustrated in the figure. This point O is called a Pole and Fig. 1*b* a Polar Diagram.

Since the point of application of the right-hand reaction (Fig. 1*a*) is the only one of its elements which is known, we must begin at this point 1 when drawing the Funicular Polygon 1 2 3 4 5. In the Polar Diagram, Fig. 1*b*, the line O F comes between the loads E F and F G. Then, from the point 1, in the Frame Diagram, draw the line 1—2, parallel to O F. The line 1—2 begins in the line of action of the load F G and ends in the line of action of the load E F—viz., the two loads between which the line O F lies in the Polar Diagram. Between the lines of action of the loads E F and D E, draw the line 2—3 parallel to the line O E in the Polar Diagram, which lies between these same two loads. Similarly draw 3—4 parallel to O D and 4—5 parallel to O C. On joining the point 5 with the point 1 we close the Funicular Polygon. This closing line 5—1 has one end 5, in the line of action of the reaction A B, and the other end 1, in the line of action of the reaction A G. Therefore, if a line O A be drawn parallel to this closing line from O, it must lie between the reactions in the line of loads, just as the other lines radiating from O have done.

If we draw B A from B in the line of loads parallel to the line of action of the reaction A B, so as to meet the line O A in the

point A, then A joined with G completes the external force polygon.

Second Case.—If the two ends of the beam had been anchored, then the lines of action of the reactions G A and A B would have been parallel to each other and to the line joining B with G in the Load Diagram. In this case the lines of action of the

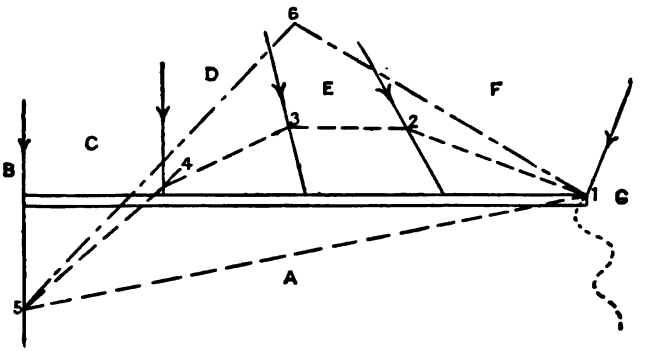

FIG. 1*a*.—FRAME DIAGRAM AND FUNICULAR POLYGON.

reactions would be drawn on Fig. 1*a*, and the point 1 taken anywhere in the line of the reaction G A; or we could begin with the point 5 anywhere in the line of the reaction A B, and draw the Funicular Polygon as stated above.

If the load F G had not existed, we would still have begun at the point 1 for the first case. The line O F would then be between the load E F and the reaction F A. In the second case mentioned above, the solution would still be the same as before.

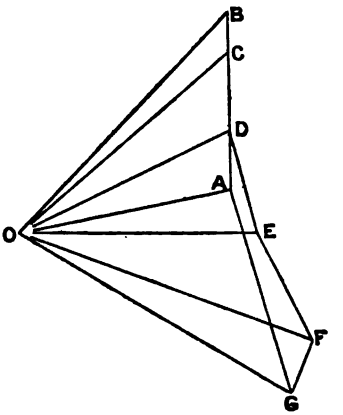

FIG. 1*b*.—LOAD AND POLAR DIAGRAM FOR DETERMINATION OF REACTIONS AND RESULTANT LOAD.

Resultant of the Loads on a Beam.—From the point 1 in the Frame Diagram, Fig. 1*a*, draw the line 1—6 parallel to the line O G in the Polar Diagram. This line O G lies between the load F G and the resultant G B. Now draw the line 5—6

parallel to the line O B, so as to intersect the line 1—6 in the point 6. Then the point 6 is a point in the line of action of the resultant of the loads. If through the point 6 we draw a line parallel to B G, then that line will represent the line of action of the resultant load. This line cuts the beam at the point round which the beam would balance. The magnitude of the resultant is represented by the length of the line B G.

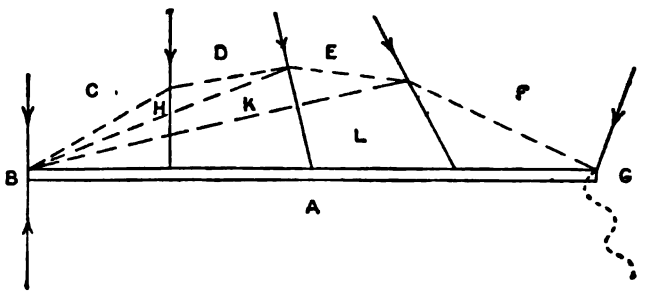

FIG. 2*a*.—FRAME DIAGRAM.

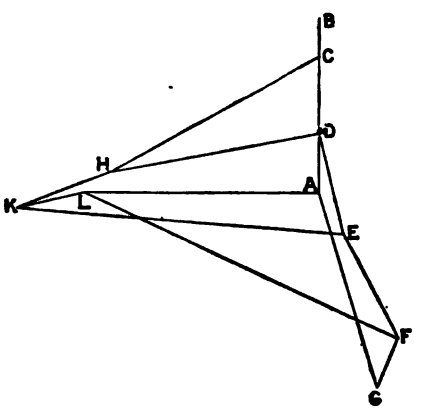

FIG. 2*b*.—LOAD AND REACTION DIAGRAM FOR DETERMINATION OF REACTIONS.

If we wished to find a point in the line of action of the resultant of the loads C D, D E, and E F, then from the point 2, draw a line parallel to the line O F, and from the point 4 a line parallel to the line O C, so as to intersect the first line from the point 2. This point of intersection is a point in the line of action of the resultant of C D, D E, and E F. Its line of action passes through this point and is parallel to the line joining C with F, while its magnitude is represented by the line C F.

Reactions on a Beam.—SECOND METHOD.—On the top of the beam draw a Firm Frame of any shape, having its joints in the lines of action of the loads as indicated in the Frame Diagram, Fig. 2*a*. Letter the Frame Diagram according to

Bow's method, and draw the Load and Stress Diagram as already explained. As a graphic solution the second method is the more accurate of the two, and may be applied with greater ease in the case of lattice girders, for we have only to join the points of the girder with one end, or some points with one end, and the remainder with the other end.

Fink Truss.—This truss was largely used in America for wooden bridges and is represented in the Frame Diagram, Fig. 3*a*. It consists in this case, of a primary truss B A G, and two secondary trusses. The divisions of the beam are called panels. The truss in Fig. 3*a* is therefore a Fink Truss of four panels.

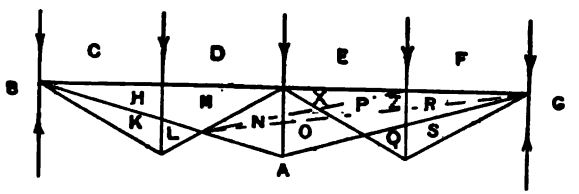

FIG. 3*a*.—FRAME DIAGRAM, FOR A FINK TRUSS.

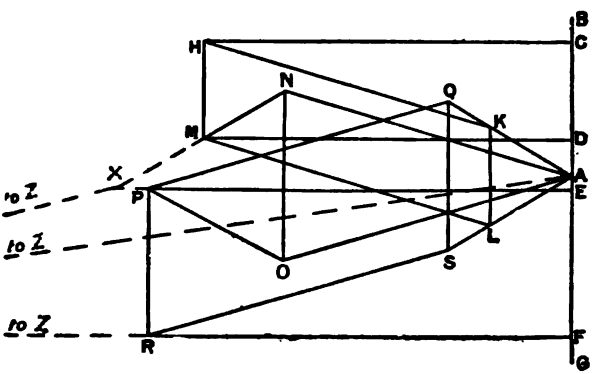

FIG. 3*b*.—STRESS DIAGRAM.

If the foot of every upright had been joined with each end of the beam instead of as shown, the truss would be called the **Bollman Truss**, of which the solution is similar to the following explanation for the Fink Truss. Draw the external force polygon as explained for Figs. 1*a* and 2*a*.

FIRST METHOD FOR STRESS DIAGRAM.—Join the joint M N A L with the joints E F R P and F G A S R, as shown by the dotted lines in the Frame Diagram, Fig. 3*a*. Call the spaces thus formed

X and Z as shown in the Frame Diagram. This will enable us to determine the point M in the Stress Diagram, Fig. 3*b*. Draw F Z and A Z, parallel to the bars F Z and A Z. This gives the point Z. Then Z X and E X fix the point X; and X M and D M fix the point M. The Stress Diagram may now be completed in the usual way, and the closing line will form a check line.

SECOND METHOD FOR STRESS DIAGRAM.—In Fig. 4, we have four forces in equilibrium acting at a point and their lines of action lie along two straight lines. The condition for equilibrium is, that H M is equal and opposite to K L and M L is equal and opposite to K H. The Force Polygon will therefore be a parallelogram and may be represented by H M L K in the Stress Diagram, Fig. 3*b*.

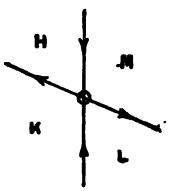

FIG. 4.—FORCES ACTING IN STRAIGHT LINES AT A POINT.

From the above, it is evident that the stress in H M must be equal to the load C D and the stress in K L equal to the stress in H M. Therefore, draw A K and A L parallel to the bars A K and A L respectively and draw K L between them parallel and equal in length to C D. This will determine the points K and L in the Stress Diagram, Fig. 3*b*, which may now be completed. The closing line will form a check as in the first method.

Trapezoidal Truss of Three Panels.—In this Truss, Fig. 5*a*, the space F will always remain a parallelogram, as was the case in the Queen Post Frame which has been already discussed. In fact this is a similar case to the roof considered with a continuous tie-beam.

If the beam is uniformly rigid, then whatever distance the joint C D G F is deflected below the horizontal line, the joint B C F E rises an equal distance above the horizontal line. Therefore, the difference between the vertical component of the load C D and the stress action in G F, must be equal and opposite to the difference between the vertical component of the load B C and the stress action in E F.

In order to obtain the Stress Diagram, Fig. 5*b*, we first of all draw the external force polygon B C D A, and determine the point A, as explained for Figs. 1*b* or 2*b*. Then draw A F parallel to the bar A F and $B_1 C_1 D_1$ perpendicular to A F. $B B_1$, $C C_1$ and $D D_1$ are parallel to A F. $B_1 C_1$ and $C_1 D_1$ will be the vertical components of B C and C D respectively.

Since $C_1 D_1$ is greater than $B_1 C_1$, the joint C D G F will be deflected downwards. Therefore, F G will be less than $C_1 D_1$

and is as much less than $B_1 C_1$ as $C_1 D_1$ is less than E F. This is the same thing as saying that G F and F E are together equal to $B_1 D_1$.

The point E lies on the line A E drawn parallel to the bar

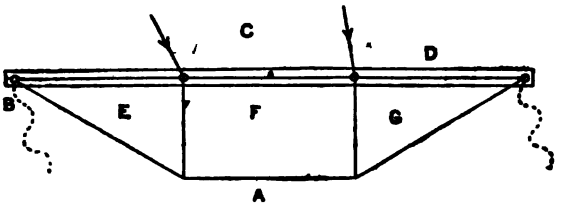

FIG. 5a.—FRAME DIAGRAM FOR A TRAPEZOIDAL TRUSS.

A E and similarly for the point G. Place the line E G between the lines A E and A G, parallel to the bars G F and F E and equal in length to $B_1 D_1$. This determines the points E and G. Where E G cuts the line A F fixes the point F. Then by joining F C, E B and G D we complete the Stress Diagram.

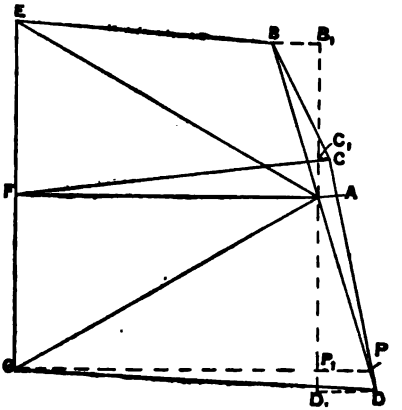

Fig. 5b.—STRESS DIAGRAM.

Another method of determining the point G is to make $A P_1$ equal to one-half of $B_1 D_1$, or A P equal to one-half of B D, and draw P_1 G or P G parallel to A F, so as to cut the line A G. This determines the point G.

Trapezoidal Truss of Five Panels.—In this truss, Fig. 6a, the space O always remains a parallelogram, but the other spaces cannot change. Similar reasoning to what we used in the previous figure will show that the loads D E and E F are together equal and opposite to the sum of the stress actions P O and O N. The load C D is equal to the stress in L N, and also equal to the stress in K M. Similarly the load F G is equal to the stresses in the bars P R and Q S. It follows from this, that the stresses R P, P O, O N, and N L are together equal and opposite to the loads C D, D E, E F, and F G. The Stress

Diagram, Fig. 6*b*, may be determined by drawing A K parallel to the bar A K, and making K M equal to C D. Then through M draw M N parallel to the bar M N. The point N lies on this

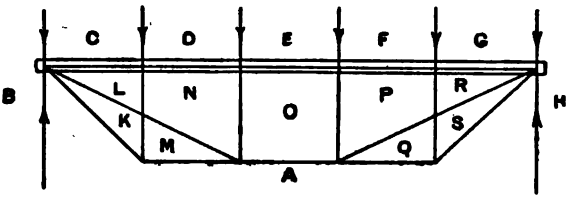

FIG. 6*a*.—FRAME DIAGRAM FOR FIVE PANEL TRAPEZOIDAL TRUSS.

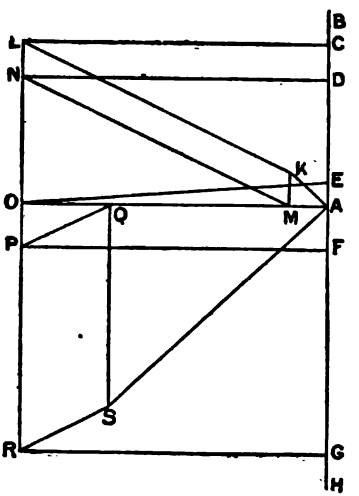

FIG. 6*b*.—STRESS DIAGRAM.

line. Draw A S parallel to the bar A S, and make S Q equal in length to F G. Through Q draw Q P parallel to the bar Q P. The point P lies on this line. Now O P and O N are together equal to F E and E D. Consequently, if we make P N equal to F D and parallel to the bars O P and O N, this will determine the points P and N. Draw A O parallel to the bar A O. This fixes the point O. The points L and R may now be determined, and the finishing lines of the diagram inserted.

In Fig. 7 the forces acting on the left-hand portion of the beam are shown as taken from the Stress Diagram, Fig. 6*b*. They are the actions of the pins on the beam, and of the right-hand half on that end.

In Fig. 8 is shown the form which the left-hand end must take from the previous assumptions. The three points shown



FIG. 7.—FORCES ACTING ON THE LEFT-HAND HALF OF THE BEAM.

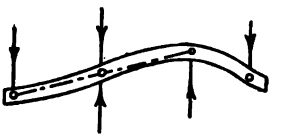

FIG. 8.—FORM INTO WHICH THE FORCES BEND THE LEFT-HAND HALF OF THE BEAM.

in a straight line must always remain in a straight line. There will be three points of contrary flexure in the length of the beam.

These Trapezoidal Trusses are deficient frames made redundant by stiff joints.

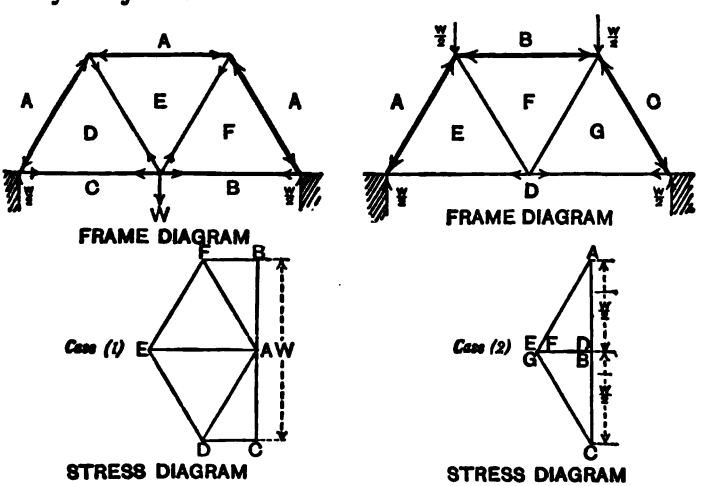

TRIANGULAR FRAME.

EXAMPLE I.—A triangular frame, consisting of three equilateral triangles, is loaded with a weight W. Find the stresses on the several members of the frame (1) when W is hung at the lower apex of the central triangle, (2) when each of the triangles is loaded at the upper apex with $\frac{W}{2}$.

ANSWER.—Since the loading is symmetrical in both cases, the reactions are each equal to one-half of the total load—that is, to $\frac{1}{2}$ W.

Case (1).—Draw B C vertical and equal to W units. Bisect it at A, so that C A and A B are the reactions. Make C D parallel to the bar C D, and A D to A D. This gives us D. Then draw D E and A E respectively parallel to the bars D E and A E, so as to obtain E. A F and E F fix F, and B F completes the Stress Diagram. B F should be parallel to the bar B F, and this gives us a check on our work.

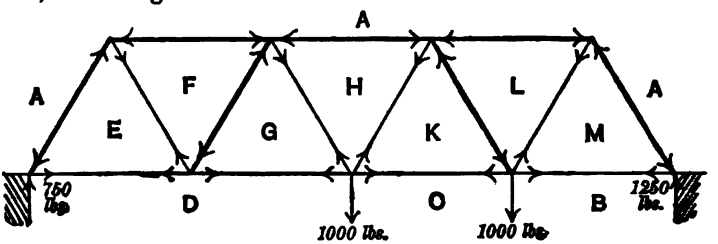

FRAME DIAGRAM

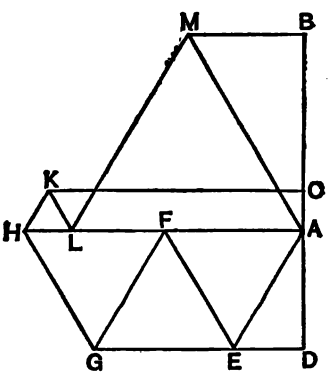

STRESS DIAGRAM

FIG. 9.—WARREN GIRDER.

Case (2).—Here we must make A B and B C each equal to $\frac{1}{2}$ W. D A and C D will represent the reactions, D being the middle point of B C, and therefore coincident with B. A E and D E determine E, and C G and D G give G. E and G will coincide since B and D do, and everything is symmetrical. The point F also coincides with E and G, so that there is no stress in the bars E F and F G.

Warren Girder.—Fig. 9 illustrates a Warren Girder of four bays or panels, which is simply an extension of the above triangular frame. The upper horizontal member is called the **Upper Boom** or **Flange**, and the lower horizontal member is called the **Lower Boom** or **Flange**. The inclined members are called **Lattice Bars** or **Braces**. The joint A F E or E F G D is called an **Apex**. The angle of triangulation is usually 60°, but sometimes the triangles are right-angled isosceles. When loads are applied at the centres of the lower members, tie-rods are put from the centres of the lower members to the opposite apices. These tie-rods transmit the central loads to the upper apices. The Frame Diagram would then show a system of loads at the lower and upper apices. From what has already been said the student should find no difficulty in drawing the Stress Diagram, which is obtained in exactly the same way as those in Example I.

Linville or N Girder.—This girder differs from the Warren Girder, in that the bars connecting the two horizontal booms are placed alternately vertical and oblique, forming a series of right-angled triangles instead of the corresponding equilateral ones in the Warren Girder. It is so arranged that the shorter vertical bars shall be in compression and the oblique ones in tension. This clearly tends to a saving of material and a diminution of weight, since compression members, unless very short, must, other things being equal, be much heavier than tension members. Also, compression members are much strengthened by shortening, while a tension member is not weakened by lengthening.

We may determine the reactions by a "substituted frame" by the Funicular Polygon, or, in this case, by calculation.

In drawing the Stress Diagram we observe that A a must be equal to Q A, and a Q is zero, since the reaction is vertical. The members a Q and n K are necessary to give the required stability. These, together with the end vertical members, might be dispensed with by carrying the supports up to the upper boom.

Draw the lines representing the loads and reactions, viz.:—K L, L M, M N, N P, P Q, Q A, A B, B C, C D, D E, E F, F G, G H, and H K. Since A a = A Q, and H n = H K, so that a coincides with Q, and n with K, we may draw the Stress Diagram as follows:—

B b	and	a b	fix the point	b,	and	G m	and	n m	the point	m.	
P c	„	b c	„	c,	„	L l	„	m l	„	l.	
C d	„	c d	„	d,	„	F k	„	l k	„	k.	
N e	„	d e	„	e,	„	M h	„	k h	„	h.	
D f	„	e f	„	f,	„	E g	„	h g	„	g.	

By t en joining fg we complete the Stress Diagram, and this line should be parallel to the central strut.

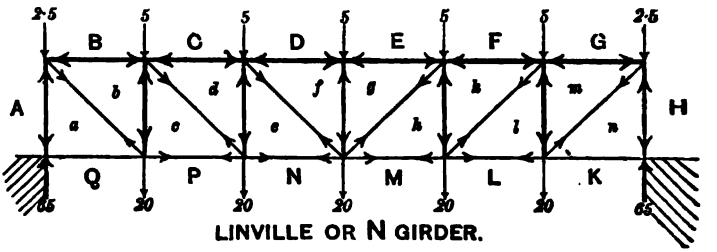

FIG. 10a.

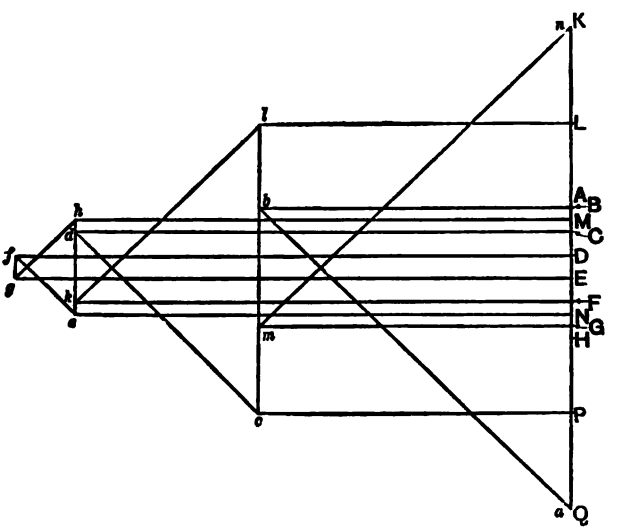

FIG. 10b.—STRESS DIAGRAM.

Lattice Girder.—Although in Fig. 12, we have drawn the external force polygon for Fig. 11, we can go no further with the Stress Diagram for frames of this kind until we have determined in some way the stress in one member, because these are redundant frames.*

* See the beginning of Lecture XXIV. for the properties of redundant frames.

ASSUMPTION.—**We assume, first of all, that all the members have been accurately fitted; that is, the frame is not initially stressed.**

One method of solution which has often been suggested is, to assume that the shear over any section is taken equally by the braces in that section. We shall however prove that this latter assumption is not consistent with the actual conditions. The shear on the right-hand bay of Fig. 11 is evidently one-half of B C, and according to the above method, the vertical component of the stress in the member G H would be equal to one half of the shear, that is one quarter of B C,

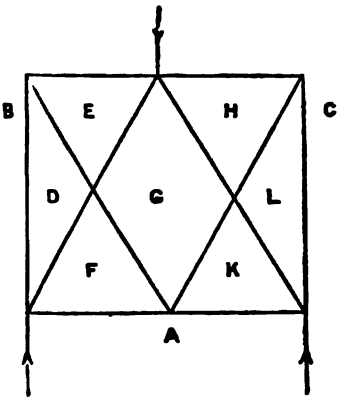

FIG. 11.—FRAME DIAGRAM.

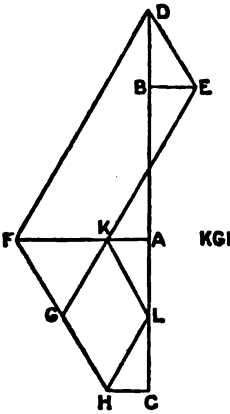

FIG. 12.—STRESS DIAGRAM WITH UNEQUAL STRESSES IN BRACES.

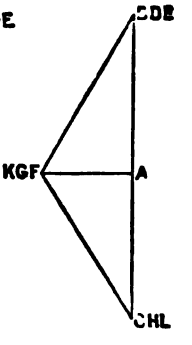

FIG. 13.—STRESS DIAGRAM WITH EQUAL STRESSES IN BRACES.

TWO BAY LATTICE GIRDER.

whilst the vertical component of the stress in the member G K would be equal to the other half of the shear, that is also one quarter of B C. Similarly, for the left-hand bay, according to the above assumption, the vertical components of the stresses in E G and F G would each be one quarter of B C.

Let us suppose the vertical component of the stress in G H and K L, to be one-quarter of B C, and then draw the Stress Diagram, Fig. 12. There A L is equal in length to the vertical component of K L and also equal to one-quarter of B C. The Stress Diagram may now be completed in the usual way. It shows that if the stress in G H has a vertical com-

ponent of one-quarter of B C, then the vertical component of the stress in E G is three-quarters of B C. This is a consistent result, because three-quarters and one-quarter of B C acting vertically together at the joint E B C H G will balance B C. But, if the members have been properly put together, there is no reason at all why the stress in E G should be greater than the stress in G H. The most sensible assumption to make is, that

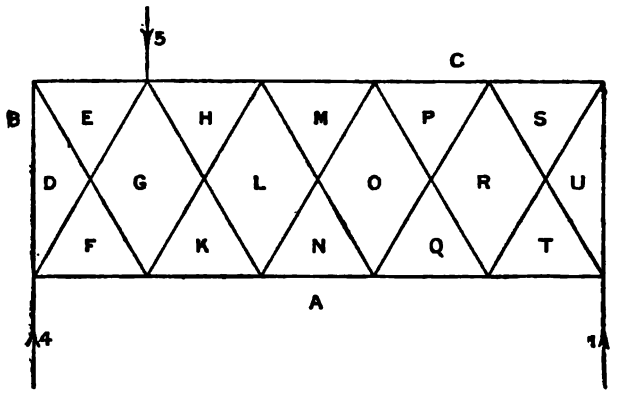

FIG. 14a.—FRAME DIAGRAM FOR FIVE-BAY LATTICE GIRDER.

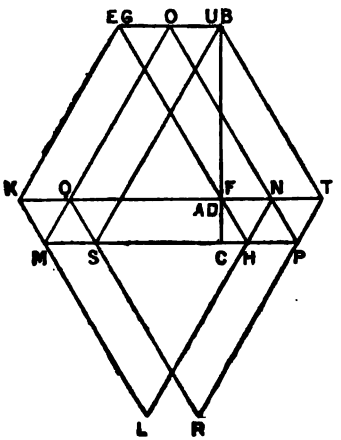

FIG. 14b.—STRESS DIAGRAM. WHEN BRACES E G AND D F ARE REMOVED.

the members E G and G H will each have a stress of which the vertical component is one-half of B C. The Stress Diagram for this assumption is worked out in Fig. 13.

Lattice Girder of Five Bays.—TO DETERMINE WHAT PROPORTION OF A SINGLE LOAD IS TRANSMITTED ALONG EACH BRACE.—In the Frame Diagram, Fig. 14a, we have assumed a load of 5 units at the joint B C H G E. From inspection, it will be evident that the reaction A B will be 4 units and A C will be 1 unit. The reactions may be determined by a substituted triangular frame with

its vertex at the loaded joint and rafter ends at the abutments. The Stress Diagram, Fig. 14*b*, has been drawn on the assumption that the braces E G and D F have been withdrawn. If the bar D F is removed, then the spaces D and F will have only one letter, let this be called D. Then B D and A D fix the point D; D F and A F the point F; D E and B E the point E; E G and F G the point G and so on, until the Stress Diagram is completed.

From the Stress Diagram, Fig. 14*b*, we see that the vertical components of the stresses in the braces * G H, K L, L N, M O, O P, Q R, R T, S U and U C are each equal to the load B C, and that the vertical components of the stresses in the remaining braces T U, R S, on to B D are each equal to four units; also that the kind of stress alternates between a push and a pull throughout the braces. The vertical component of the push in the lattice bar G H, is balanced by the vertical component of the pull in L N. Also, the vertical component of the pull in M O, is balanced by the vertical component of the push in O P, and similarly for Q R and R T, S U and U C. Now, the push in U C is balanced by the reaction C A, combined with the vertical component of the pull in T U, and since the reaction C A is one unit the vertical component of the pull in T U must be four units. This four units of vertical component of the pull in T U, is transmitted through the remaining lattice bars as a push and a pull alternately, until it reaches B D as a push, and is there balanced by the reaction A B.

The stress in each lattice bar produces a strain that will cause the load to dip. Now, since the stresses are severe and every lattice bar is stressed, the removal of the brace E G produces a very yielding frame.

In Fig. 15 we have the Stress Diagram which is obtained from the Frame Diagram, Fig. 14*a*, by removing the brace G H. The removal of this brace means, that there will be no stress in the bars L N, M O, O P, Q R, R T and S U. Since there is no stress in S U there can be none in C S or C U. Therefore, S and U will coincide with C and the Stress Diagram can now be completed.

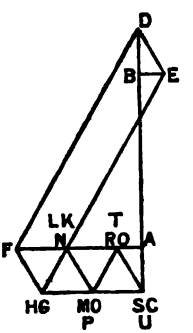

Fig. 15.—Stress Diagram with Brace G H Removed.

* Since the two members G H and K L, Fig. 14*a*, are parts of the same lattice bar or brace and the stresses in them are the same in every element, we may refer to them as the lattice bar or brace G H or K L and similarly for the others.

Fig. 15 shows that the lattice bar E G is the only one having the vertical component of its stress equal to B C. Also that each of the bars B D, D E, G K, L M, O Q and R S has the vertical component of its stress equal to one unit of the load. Further, that the stresses are alternately push and pull and that the remaining lattice bars are not stressed.

The vertical component of the push in the lattice bar E G is balanced by the reaction A B, in combination with the stress in B D. Since the vertical component of the push in the brace E G must balance the load, its value is 5 units and the reaction A B has a value of 4 units; therefore, the stress in the bar B D must be a pull of 1 unit. This vertical component of the pull in B D is balanced by the vertical component of the push stress in D E and so on, until the vertical component of the push in T U is balanced by the reaction A C of one unit.

Since the stress is severe in only one lattice bar and a number of the bars are unstressed, the removal of the brace G H produces a very much less yielding frame than the removal of the brace E G.

When the frame is complete as shown in the Frame Diagram, Fig. 14*a*, the vertical components of the pushes in the lattice bars E G and G H must together carry the load. The amount which each carries will be inversely proportional to the yieldingness of the system of bars to which each is connected. The lattice bar E G will therefore carry more than the lattice bar G H.

In this case, we have made the following assumptions:—

(1) That the Frame is not initially stressed.

(2) That the vertical component of the push stress in the left-hand lattice bar meeting in a joint at which a load is applied is equal to that portion of the left-hand reaction which that load produces. Also, that a similar relation exists between the vertical component of the push stress in the right-hand lattice bar and the right-hand reaction.

Lattice Girder Loaded at Top Joints.—For the lattice girder, Fig. 16*a*, we must first determine the reactions. This may be done by one of the methods for Figs. 1 and 2, of which the latter one, is the better and simpler. By joining the lower left-hand corner with each of the upper joints we obtain a Simple Triangular Frame, and by drawing the Stress Diagram for it, we can determine the reactions. Since the frame is redundant we must first calculate the stress in one member before we can begin the Stress Diagram. The bar B K is the most suitable one.

From the second assumption we observe that:—

(1) The load B C, produces no stress in K L and a push stress of 3 units in B K.

(2) The load C D, produces a push stress having a vertical component equal to 4 units ($\frac{4}{5}$ C D) in K M. This component is entirely balanced by the reaction which the load C D produces in A B—viz., 4 units. This load produces therefore no stress in B K.

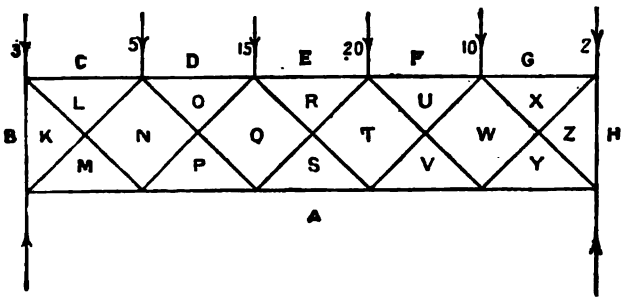

Fig. 16*a*.—Frame Diagram for a Loaded Lattice Girder.

(3) The load D E, produces a push stress having a vertical component equal to 9 units ($\frac{3}{5}$ D E) in O Q. This stress induces a pull stress in M N having a vertical component equal to 9 units and this pull stress induces in B K a push stress of 9 units.

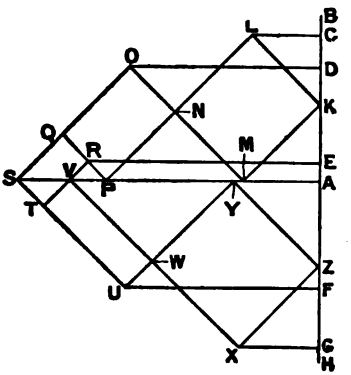

Fig. 16*b*.—Stress Diagram.

(4) The load E F, produces a push stress having a vertical component equal to 8 units ($\frac{2}{5}$ E F) in R T. This stress induces a pull in P Q, and a push in N L, the vertical component of which is balanced by the reaction produced in A B. This load produces therefore no stress in B K.

(5) The load F G, produces a push stress having a vertical component equal to 2 units ($\frac{1}{5}$ F G) in U W. This stress is transmitted as push and pull until it reaches B K as push and is balanced by the reaction A B.

(6) The load G H, produces no stress in B K.

Summing up the push stresses in B K we have :—

3 units due to B C,
0 units due to C D,
9 units due to D E,
0 units due to E F,
2 units due to F G,
0 units due to G H.

This gives a total push stress of 14 units in the bar B K.

From the point B, in the line of loads, Fig. 16*b*, draw a line B K parallel to the bar B K, and make the length of B K equal to 14 units to the same scale as the line of loads. This determines the point K in the Stress Diagram. Then K L and C L fix the point L and so on point by point until the Stress Diagram is finished. The finishing line forms a check line.

In calculating the stress in the lattice bars, we have sometimes a push stress and sometimes a pull stress. We must therefore pay due regard to the sign of the stress when adding up the various stresses. The force C D produces a push stress in the bar N O, having a vertical component of 1 unit, while E F produces a push stress in R T having a vertical component of 8 units. This push induces a pull in N O also having a vertical component of 8 units. Therefore, the resultant stress in N O is a pull having a vertical component of 7 units.

Referring to Fig. 16*a*, we may observe that sometimes, vertical ties are put in the spaces N, Q, T and W. The action of these ties is to prevent distortion of the rectangles in which they lie. Therefore unless these rectangles have become distorted, they will not be stressed. This distortion will depend upon the relative yieldingness of the two systems of bars forming the rectangle. In this example suppose a tie in the space N and a load applied at the lower joint. Then, before this load can stress the tie, the lower joint must come down more than the upper joint. The safest assumption to make is, that the ties carry no portion of the loads. Some lattice bridges have struts in the spaces N, Q, T and W of Fig. 16*a* and the lattice bars are all ties—that is, they are only able to stand a pull stress. On drawing the Stress Diagram for such a case, we must omit a bar if a push stress comes in it, and use the other tie.

One tie in each bay must carry the shear in that bay. This will enable us to calculate the pull in that tie. This is the best method of drawing the Stress Diagram for such cases.

Bending Moment.—DEFINITION.—**The Bending Moment at any point in a beam, is the algebraic sum of the moments with respect to that point, of all the external forces acting on the portion of the beam on either side of that point.**

In order to draw the Bending Moment Diagram of Fig. 17, we must proceed as if we were going to find the reactions, by means of the Funicular Polygon and Polar Diagram as explained for Fig. 1*a*.

The Funicular Polygon drawn in this way is a Bending Moment Diagram.—That is, if a vertical line be drawn from a point in the beam, to cut the bounding lines of the Funicular Polygon,

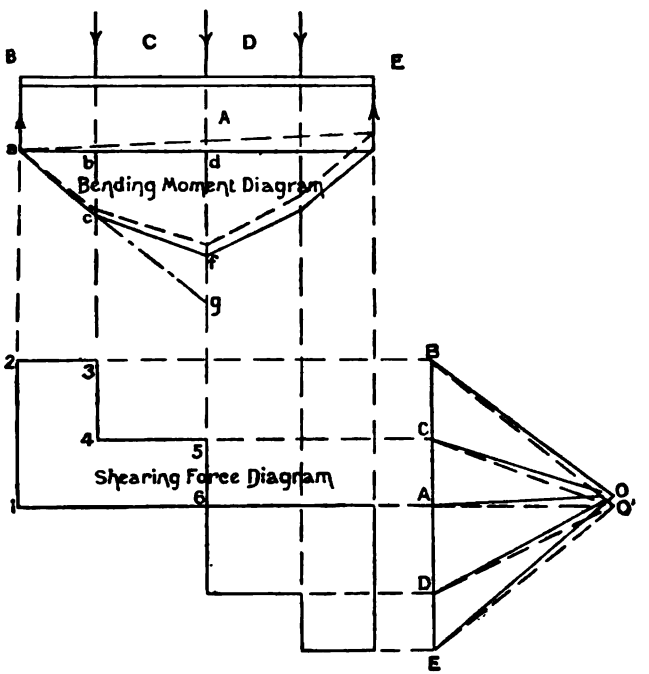

Fig. 17.—Bending Moment and Shearing Force on a Beam.

the intercept on this line which lies between those bounding lines, represents to a certain scale the bending moment on the beam at that point.

Having found the point A in the line of loads, by drawing A O' horizontal and of any suitable length, we draw a Polar Diagram with this point O' as the pole and the corresponding Funicular Polygon, when we obtain a Bending Moment Diagram on a horizontal base.

Proof.—The Bending Moment at the point where the load

B C acts, is equal to A B × $a\,b$ Units of Moment. The Triangles $a\,b\,c$ and O′ A B are similar, having the sides $a\,b$, $b\,c$ and $c\,a$ of the one respectively parallel to the sides O′ A, A B and B O′ of the other.

Therefore, $b\,c : a\,b :: \mathrm{B\,A} : \mathrm{A\,O'}$

Hence, $$b\,c = \frac{\mathrm{B\,A} \times a\,b}{\mathrm{A\,O'}}$$

Similarly, $$d\,f = \frac{\mathrm{B\,A} \times a\,d - \mathrm{B\,C} \times b\,d}{\mathrm{A\,O'}}.$$

That is, the number of units of length in $b\,c$, when measured with the scale for the load line, would give the Bending Moment, if O′ A measured 1 unit on the scale of length for the Beam.

SCALE FOR BENDING MOMENT DIAGRAM.—**Subdivide the unit of the scale used for the line of loads, into as many parts as the line O′ A contains the unit of the scale used for the length of the beam. Then, one of these subdivisions will be the unit for the Bending Moment scale.** It is found convenient to make O′ A ten units of the length scale.

Shearing Force.—DEFINITION.—**The Shearing Force on any transverse section of a beam is equal to the algebraic sum of all the external forces acting on the portion of the beam on either side of that section.**

In order to draw the **Shearing Force Diagram** of Fig. 17, no explanation is necessary, beyond following out the lines of the figure. The Shearing Force on any transverse section of the beam lying between the loads B C and C D, is, from the definition, equal to the force A B minus the force B C. Therefore, the length between the line 4—5 and the line 1—6 will measure the Shearing Force to the scale of the line of loads.

Cantilever Uniformly Loaded.—The cantilever shown in Fig. 18 may be considered as 12 feet long. The loads indicated are therefore equivalent to a uniform load per foot run. They act at the centre of each of the portions. By drawing from A, B, C, &c., on the Load Line, horizontal lines in the spaces A, B, C, &c., as shown, we determine the Shearing Force Diagram. If we divide the beam into smaller divisions and draw the Shearing Force Diagram, the stepped line will become more nearly a straight line. Consequently, when divided into infinitely small parts, the Shearing Force Diagram becomes the Triangle R P Q. The length of the line Q R is the total load on the Beam.

The Bending Moment Diagram of Fig. 18 is determined by drawing in the spaces A, B, C, &c., lines parallel to the lines O A, O B, O C, &c. The limiting form of the curve Q S will be a parabola with its vertex at S, and the value of the length Q T will be the Maximum Bending Moment.

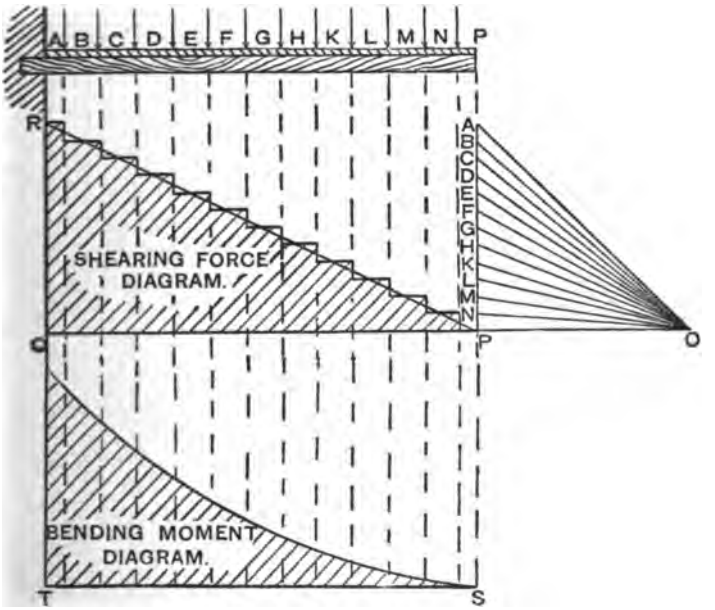

FIG. 18.—UNIFORMLY LOADED CANTILEVER.

Beam Uniformly Loaded and with Concentrated Loads.—Draw, as already explained, the Shearing Force Diagram for the concentrated loads. This is H A *1 2 3*, &c., on Fig. 19. Set off H P and K Q, each equal to half the total uniform load on the beam, and join P with Q. Then H P Q K is the Shearing Force Diagram for the Uniform Load. Adding the ordinates of the two diagrams together we derive the Combined Shearing Force Diagram H *a b c d e 5 6 f*, &c., of Fig. 19.

Draw the Bending Moment Diagram (L *n* M, Fig. 19) for the concentrated loads as described for Fig. 17. Then draw on the opposite side of L M a parabola, having its axis bisecting L M at right angles, and the ordinate at the centre of L M equal to the Maximum Bending Moment due to the uniform load. This

ordinate must be measured to the same scale as that of the ordinates of the concentrated Bending Moment Curve. The combined ordinate measures the Combined Bending Moment.

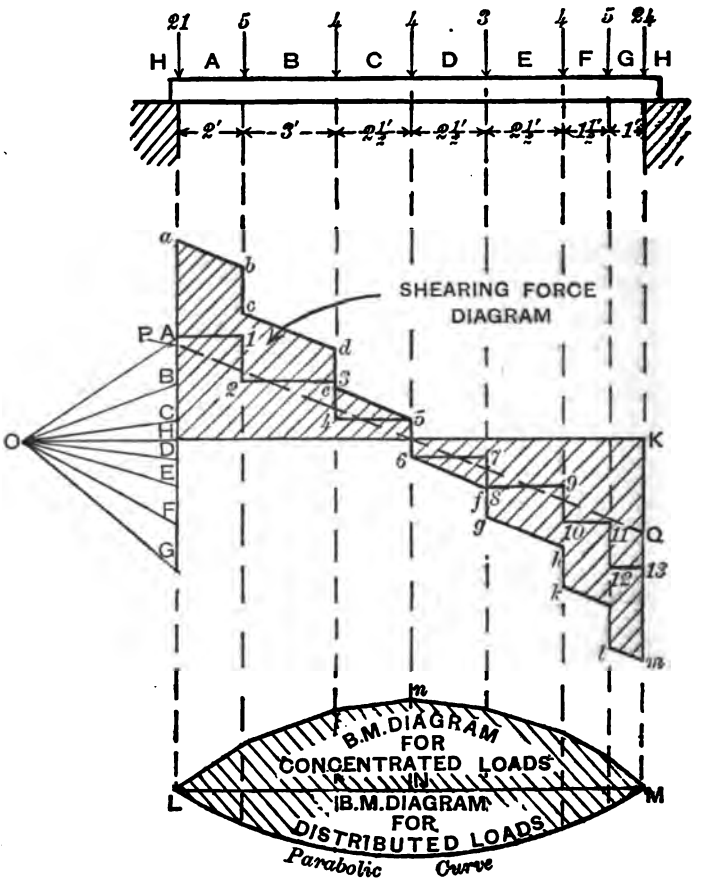

FIG. 19.—BEAM WITH UNIFORM AND CONCENTRATED LOADS.

EXAMPLE II.—A cantilever 15 feet long has a load of 5 tons at its outer end, 5 tons at 5 feet from it, and 10 tons at a point 10 feet from the end. Find graphically the diagrams of shearing force and bending moment.

ANSWER.—The upper part of the figure shows the cantilever

and the positions of the loads. Project down from these positions and the inner end of the beam, and then set out A B = 10 units, B C = 5, and C D = 5, to represent the forces A B, B C,

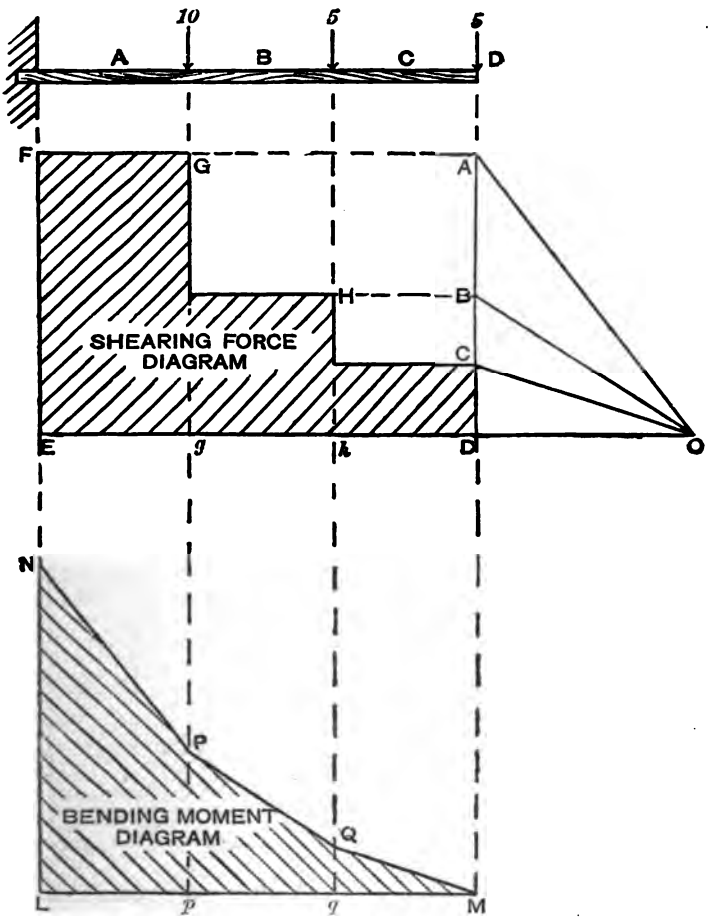

CANTILEVER IN EXAMPLE II.

and C D respectively. Draw horizontal lines through A, B, C, and D to intersect the lines of the forces. This gives us the Shearing Force Diagram as shown shaded.

To obtain the Bending Moment Diagram take any point O in E D, and join it to A, B, and C. Then take a base line M L parallel to O D, and draw M Q in the space C parallel to O C, Q P in the space B parallel to O B, and P N in the space A parallel to O A. Then L M Q P N is the Bending Moment

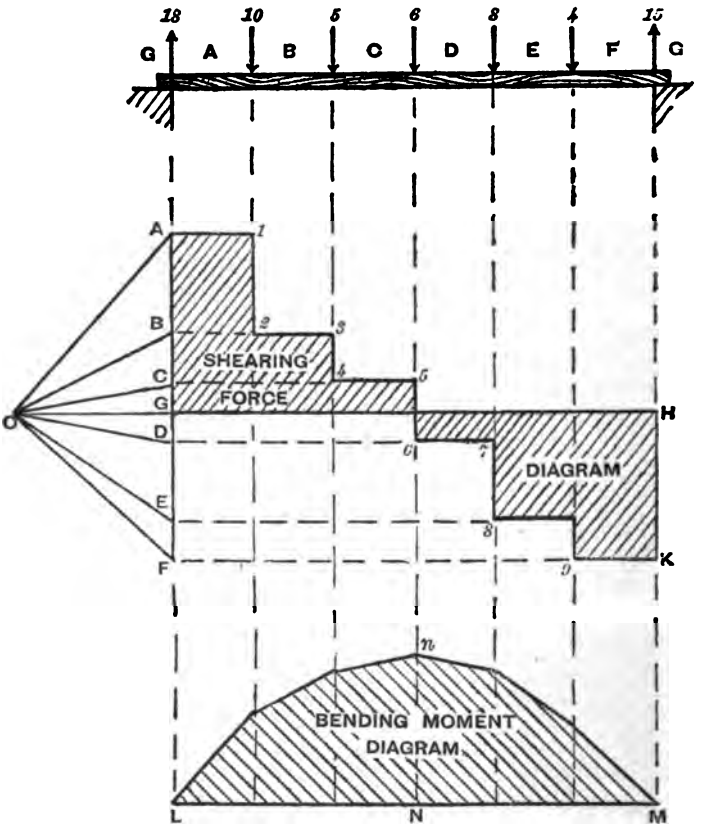

BEAM IN EXAMPLE III.

Diagram, the scale being that adopted for the shear multiplied by the length of O D measured on the scale employed in setting out the length of the beam.

EXAMPLE III.—A beam of 12 feet span carries five loads equally spaced along its length, the first and last being each 2

feet from the nearest end. The values of the loads are 10, 5, 6, 8, and 4 tons respectively. Obtain graphically diagrams showing the shear and bending moment at every point of the beam.

ANSWER.—In this case we shall determine the reactions by calculation, thus:—

Reaction at left hand due to		A B is	$\frac{5}{6} \times 10 = 8\frac{1}{3}$	tons.
"	"	B C "	$\frac{4}{6} \times 5 = 3\frac{1}{3}$	"
"	"	C D "	$\frac{3}{6} \times 6 = 3$	"
"	"	D E "	$\frac{2}{6} \times 8 = 2\frac{2}{3}$	"
"	"	E F "	$\frac{1}{6} \times 4 = 0\frac{2}{3}$	"
∴ Total left-hand reaction			G A = 18	"

The whole load is 33 tons, and therefore the right-hand reaction must be 33 – 18, or 15 tons.

We can now proceed as before, making G A = 18, A B = 10, B C = 5, &c., and drawing horizontal lines through A, B, C, &c., to obtain the Shearing Force Diagram.

Take a point O in the horizontal through G, and join it to A, B, C, &c.

Then the part of the Bending Moment Diagram in the space A is parallel to O A, in the space B to O B, in C to O C, and so on, as in Example II.

We might, of course, have determined the reactions from the Funicular Polygon L *n* M N in the first instance; but had we done so we would probably not have got the line O G horizontal, and would have had to redraw it as explained in the text.

Centre of Gravity of an Area.—Divide the area into elements, such as parallelograms, triangles, &c., the centres of gravity of which can be easily determined.

If the area is bounded by a curved line, divide it into very narrow strips, so that they may be considered approximately as parallelograms.

We have divided the area shown in Fig. 20 into three rectangles, and have found the centre of gravity of each. We first, assume a line lying in any direction, such as the line X X, along which the pull of gravity acts. The centre of gravity of each area is a point in the line of action of the pull of gravity on that area. The line of action of gravity will be parallel to this assumed line X X. The way may be towards either the left or the right as may be found most suitable, and the magnitude will be proportional to the area. The forces B C, C D, and D E represent completely the action of gravity on the top, the centre, and the bottom rectangles respectively.

Proceed to find the resultant of the three forces B C, C D,

and D E, as explained for Fig. 1*a*. This is shown in Fig. 19 by the Polar Diagram B C D E O, and the corresponding funicular polygon 1 2 3 4. B C, C D, and D E, in the Polar Diagram are proportional to the areas of the three rectangles.

The line of action of the resultant of the three forces B C, C D, and D E passes through the centre of gravity of the whole area. This line is represented by the line 4—M. Now, assume a line at right angles to X X as a line along which the pull of gravity acts. Proceed in exactly the same way with regard to this line as has been done for the line X X, and we obtain another line passing through the centre of gravity of the

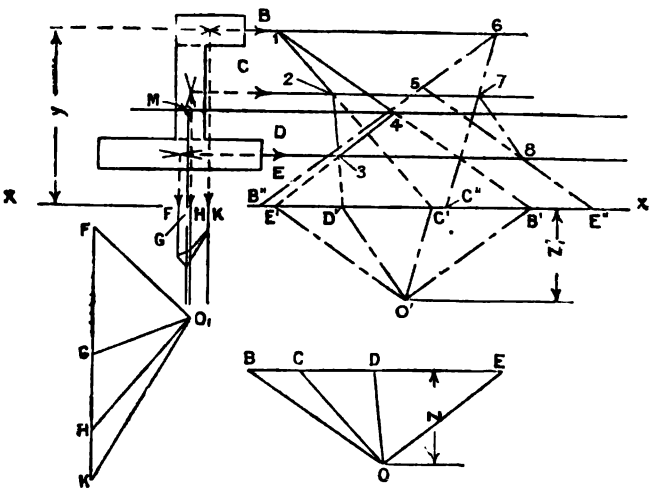

FIG. 20.—CENTRE OF GRAVITY AND MOMENT OF INERTIA.

whole area. The intersection M of these two resultants gives the centre of gravity of the whole area. The forces in the second case are called F G, G H, and H K, and the Polar Diagram F G H K O_1, with its corresponding Funicular Polygon, is shown in the figure.

Moment of Inertia of an Area.—If we wish to find approximately the Moment of Inertia round the line X X of the area in Fig. 20, we must first of all divide the area into elements just as in finding the centre of gravity. Then proceed to draw the polar diagram B C D E O and the corresponding funicular polygon 1 2 3 4

Now consider the top polygon and how we may determine its Moment of Inertia.

Produce the two lines derived from the polar diagram, which meet in the line of action of the pull of gravity on that area (viz., 1—2 and 1—4) until they intersect the line X X in the points B′, C′. Do the same for the lines 1—2 and 2—3, and 2—3 and 4—3, which meet on the lines of action of the pull of gravity on the middle and bottom areas. These lines intersect X X in the points C′, D′, and D′, E′, respectively.

Consider B′ C′, C′ D′, and D′ E′ as the magnitudes of the forces acting along the lines B C, C D, and D E respectively. Proceed as if to find their resultant by drawing the polar diagram B′ C′ D′ E′ O′ and the corresponding funicular polygon 5 6 7 8.

Produce, as before, the lines which meet in B C (viz., 6—5 and 6—7) to intersect the lines X X in the points B″ C″. Do the same for the lines 5—8 and 7—8, or, as we have done in the figure, produce the one which will cut X X in a point furthest from B″. B″ C″ measures to a certain scale the moment of inertia of the top area round the line X X, and B″ E″ the moment of inertia of the whole area round the same line. Greater accuracy would be obtained by dividing the area into smaller elements.

Proof.—Let y in Fig. 20 represent the distance the centre of gravity of the top area is from the line X X.

Now, since the two triangles B C O and B′ C′ 1 are similar:—

$$BC : Z :: B'C' : y.$$

Then,
$$B'C' = \frac{BC \times y}{Z}.$$

Again, the two triangles B′ C′ O′ and B″ C″ 6 are similar:—

Hence,
$$B'C' : Z_1 :: B''C'' : y.$$

And,
$$B''C'' = \frac{B'C' \times y}{Z_1}.$$

Substituting the above value of B′ C′ we get:—

$$B''C'' = \frac{BC \times y^2}{Z \times Z_1}.$$

But, $BC \times y^2$ is the moment of inertia for the top area with respect to the line X X, provided the depth of the area is small in comparison with y. B″ C″ measured with the scale called the "area scale," as used for drawing B C (in order to represent the area of the top rectangle), gives the value of this moment of

inertia, if Z and Z_1 are 1 unit of the scale which is used for setting off the lengths in drawing the section.

SCALE FOR MEASURING THE MOMENT OF INERTIA.—**Subdivide the unit of the scale used for representing the areas, into as many divisions as is represented by the number found by multiplying Z and Z_1, which are both measured by the length scale. One of these subdivisions will be the unit for the Moment of Inertia Scale. Or, measure B″ E″ with the area scale and multiply the reading first by Z and then by Z_1.**

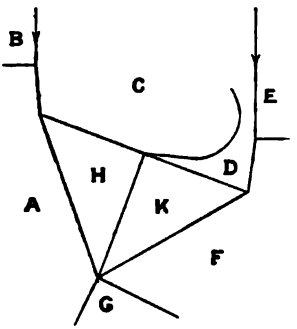

FIG. 21*a*.—FRAME DIAGRAM. ENGINE MECHANISM.

Engine Mechanism.—In the Frame Diagram, Fig. 21*a*, the bars B C and C E represent the centre lines of the piston-rods of a compound engine the heads of which are guided in parallel straight lines. The bars A C and D F are short

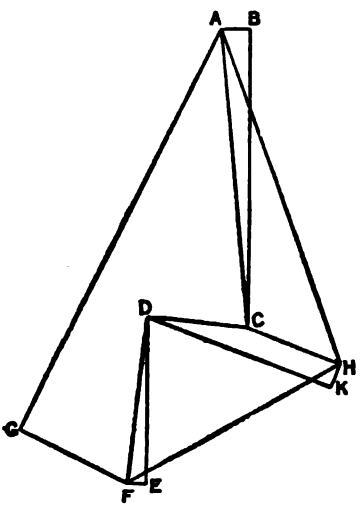

FIG. 21*b*.—STRESS DIAGRAM.

STRESS DIAGRAM FOR JOINT A C H.

connecting-rods, driving the crank F G, by means of the triangular frame shown. The joint C D K H is constrained to

move in an arc of a circle round a point in the bar C D produced towards the right. The bar C D is called a radius rod. The lines of action of all the external forces acting in the structure are shown. A B and E F are the guide pressures, C D the push or pull in the radius rod, F G the push or pull in the crank, and G A the crank effort or tangential resistance.

First Method.—We commence the Stress Diagram, Fig. 21*b*, by drawing D E to represent in magnitude the total pressure on the right-hand piston-rod. Then, E F and D F fix the point F, while F K and D K determine K.* But, we can get no further until we draw the Stress Diagram for the joint A C H. This is done by drawing B C to represent to the same scale as before the total pressure on the left-hand piston-rod. Then, the points A and H are determined.

We must now fit the Stress Diagram for the joint A C H, to the Stress Diagram already drawn; so that the point C shall lie on the line drawn through D parallel to the bar C D and the point H on the line drawn through K parallel to the bar K H, C H being kept parallel to the bar C H. Then the Stress Diagram, Fig. 21*b*, can be completed in the usual way.

Second Method.—Find the forces acting in A C and D F, and then find their resultant. Produce the line of action of this resultant to cut the line of action of the force C D; when, by joining this point with the crank pin, we get the line of action of the resultant force acting on the said crank pin. Finally, draw the Stress Diagram from the supplementary data.

The following is a list of books and papers on Graphic Statics and the Design of Structures:—

The Design of Structures, Bridges, Roofs, &c., by S. Anglin, C.E. (Chas. Griffin & Co., London, 1895.)

A Practical Treatise on Bridge Construction, by Prof. T. Claxton Fidler. (Chas. Griffin & Co., London.)

Graphical Determination of Forces in Engineering Structures, by James B. Chalmers, C.E. (Macmillan & Co., London.)

Graphic and Analytic Statics, by Robert Hudson Graham, C.E. (Crosby Lockwood & Co., London.)

Graphics, by Prof. R. H. Smith, M.Inst.M.E. (Longmans, Green & Co., London.)

Mechanics, vol. ii., by A. Jay Du Bois, C.E., Ph.D. (Chapman & Hall, London.)

Applied Mechanics, by Gaetano Lanza. (Chapman & Hall, London.)

Theory of Structures and Strength of Materials, by Henry T. Bovey, M.A., D.C.L. (Chapman & Hall, London.)

Graphic Methods of Computing Stresses in Jointed Structures. Paper by C. O. Burge, Proc. Inst. C.E. Vol. lxxiv., p. 192.

Graphic Methods of Engine Design, by A. H. Barker. (The Technical Publishing Co., Ltd., Manchester.)

* The line F K has been omitted in the diagram.

Mechanical Graphics, by G. Halliday. (London, 1889.)
Elements of Graphic Statics, by K. von Ott, translated by G. S. Clark. (E. & F. N. Spon, London, 1888.)
Principles of Graphic Statics, by G. S. Clark. (E. & F. N. Spon, London, 1888.)
Elements of Graphic Statics, by L. M. Hoskins. (Macmillan & Co., London, 1892.)
Economics of Construction, by Robt. H. Bow. (E. & F. N. Spon, London.)
Applied Mechanics, 2nd edition, by Prof. James H. Cotterill. (Macmillan & Co., London.)

LECTURE XXVIII.—QUESTIONS.

1. Draw the Stress Diagram for the Fink Truss shown below, and verify the stress diagram accompanying it.

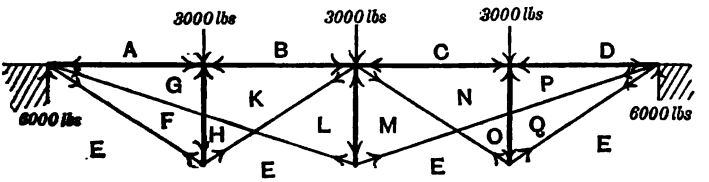

FRAME DIAGRAM

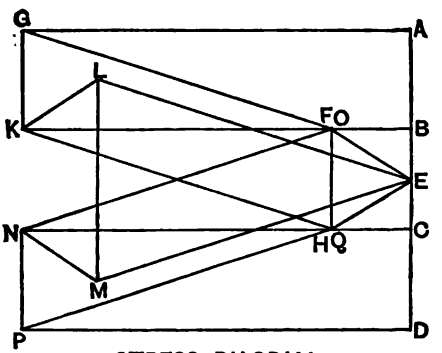

STRESS DIAGRAM

FINK TRUSS FOR QUESTION 1.

2. A triangular frame is at rest under the action of three external forces. Prove that a certain diagram will represent the stresses in the bars of the frame. Extend this proposition to the case of a lattice girder of the Warren construction with four bays in the lower boom and three bays in the upper boom, loaded in the centre of the lower boom and supported at the ends, giving the Stress Diagram and showing how to distinguish the portions which are in compression or extension. (S. and A. Adv. Exam., 1889.)

3. A triangular frame is acted on by three forces applied at its respective angular points and in equilibrium; investigate a method of constructing the diagram of all forces brought into play. Taking the case of a frame on the principle of the Warren Girder having four bays in the lower boom and three in the upper boom, and loaded at the centre of the lower member with a weight W, explain the method of constructing the diagram of forces,

drawing the same, and distinguishing those bars which act as struts from those which act as ties. (S. and A. Hons. Exam., 1892.)

4. The lower boom of a Warren Girder, supported at both ends, is divided into three bays. The upper boom has two bays, and the bracing bars are each inclined at 60° to the horizon. Find by graphic construction the stresses in the several pieces when the frame is loaded with 1,000 lbs. at the middle of the top boom.

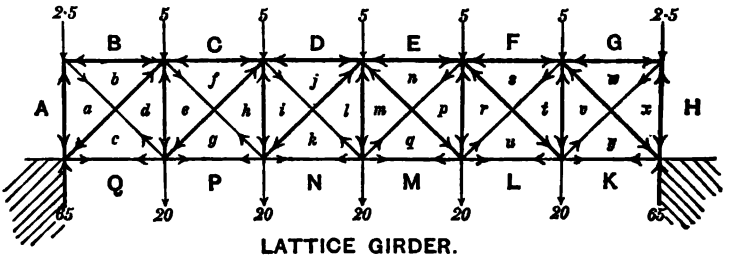

LATTICE GIRDER.

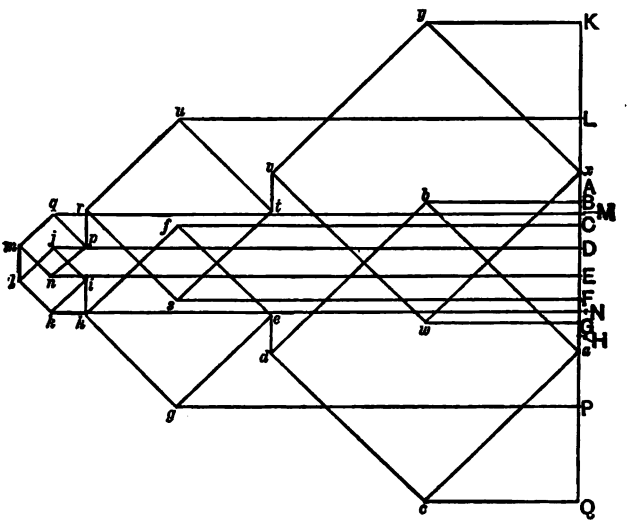

STRESS DIAGRAM.

LATTICE GIRDER FOR QUESTION 7.

5. A Warren Girder has five bays consisting of equilateral triangles. If it be supported at each end and loaded at the two bottom central joints with loads of 18,000 lbs., find graphically the stress on each member, and show whether it is tensile or compressive. Explain fully the reasons and theory of the method you employ in obtaining your result. (S. and A. Adv. Exam., 1894.)

6. A Warren Girder of six bays with equilateral bracing, each bay being 10 feet long, is loaded with a distributed weight of 1 ton per foot run placed along the top of the girder; obtain the diagram of stress, and calculate the stresses in the various members, assuming that cotan. 60° = ·577, cosec. 60° = 1·155. *Ans.*

7. A lattice girder is loaded in the manner shown by the foregoing figure. Draw the Stress Diagram by the method explained in the text, and see if you get the same results as shown.

8. A bar of pine 44 inches long rests on props at its extremities, and just supports 10 weights, of 14 lbs. each, hung at equal intervals of 4 inches along the rod. Find graphically the B M at the centre of the bar and the amount of a single weight, which, if hung at the centre of the bar, would stress it to the same extent (see figure). *Ans.* 43·27 lbs.

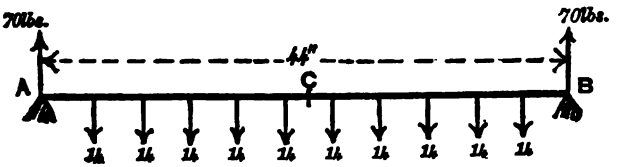

BEAM FOR QUESTION 8.

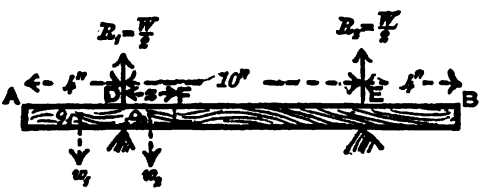

BEAM FOR QUESTION 9.

9. A horizontal uniform bar, 18 inches long, is laid over two supports, each 4 inches from its ends, as shown in the figure. Find graphically two points at which the bending moment is zero, the bar being loaded by its own weight (see figure). *Ans.* 2 inches from inside of supports.

10. Given an iron arched rib, hinged at both ends, and a system of vertical loads, show how we find the stress at any point of any section. Prove the rule for stress at any point of a section when we know the resultant of all the forces acting on the structure on one side of the section.

11. A beam, ABCDE, has a vertical supporting force at A; at E there is a pin joint support. AB is 5 feet, BC is 2 feet, CD is 6 feet, DE is 4 feet. There are vertical loads of 2 tons at B and 3 tons at D, and at C there is a load of 5 tons inclined at 30° to the vertical, its horizontal component being towards A. All forces in one plane. Find the supporting forces, graphically or otherwise. (S. & A. Adv. Exam., 1897.)

PART V.—STRENGTH OF MATERIALS.

LECTURE XXIX.

CONTENTS.—Stress—Definition of Intensity of Stress—Relation between Normal and Tangential Stresses—Strain—Example I.—Coefficient or Modulus of Elasticity—Limit of Elasticity—Work done in Stretching a Bar—Resilience—Example II.—Sudden Pull or Live Load—Shrunk Rings—Example III.—Strength of Thin Cylinders—Helical Seams—Strength of Thick Cylinders—Example IV.—Strength of Suspended Chains and Wires—Example V.—Questions.

Stress.—When a piece of material is subjected to the action of external forces they tend to cause the material to change its shape or form. The particular way in which the change takes place depends upon the manner in which the load is applied. This tendency gives rise to certain forces within the material which offer resistance to the change. These internal forces are generally called *stresses;* but the term *Stress* which we have now to consider has a somewhat more definite meaning. By the principle of the equality of action and reaction, we know that so long as no rupture of the material takes place, the algebraic sum of the components of the internal forces in the direction of the load at any section of the material must be equal to the load. This principle enables us to express the *internal* in terms of the *external* forces. It is a fundamental fact that, for a given load, the amount of resistance to be contributed by each individual fibre or part composing a section will be less or greater, according as the number of such fibres or parts is greater or less; or as we usually regard it, according as there is more or less area of section. This introduces us to the conception of *distributed* force, and paves the way towards gaining definite and clear ideas regarding the strength of materials.

DEFINITION.—**Intensity of stress is the resistance or reaction due to a load per unit area of section.** For brevity it is usually called the Stress. Stresses may be of three different kinds, depending on the direction of the applied force with reference to the section on which the stress is estimated.

(1) If the applied force is normal or at right angles to the section, and acting *away* from it, the stress is called *tensile.*

(2) If acting *towards* the section, the stress is termed *compressive.*

(3) If the direction of the applied force be *parallel* to the section, then the stress is named a *shearing* stress.

It is evident that if the applied force be acting in a direction inclined to the given section, it will cause both a shearing and a direct stress, the latter being tensile or compressive, according as the force is directed away from or towards the section.

When the applied force acts in such a way that we know that its effect is uniformily distributed over the section we are considering, then we estimate the stresses as follows :—

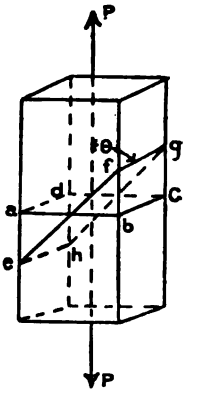

ILLUSTRATING NORMAL AND TANGENTIAL STRESSES.

Let P_n = The applied load (or its component) acting normally to the section in lbs. or tons.

" A = The area of the section (usually in square inches).

" f = The direct stress, which may be either tensile or compressive.

" P_t = The applied load (or its component) acting tangentially to the section in lbs. or tons.

" f_s = The shearing stress.

$$\left.\begin{aligned} \text{Then,} \qquad f &= \frac{P_n}{A}. \\ \text{And,} \qquad f_s &= \frac{P_t}{A}. \end{aligned}\right\} \quad \ldots\ldots\ldots \quad (I)$$

Relation between Normal and Tangential Stresses.—Let $abcd$ be the section of a bar normal to the direction of the applied force P, and $efgh$ another section making an angle θ, with the direction of P; and let the area of $abcd$ be A square inches.

Thus, the stress on $abcd$ is :—

$$f = \frac{P}{A};$$

But, on the area $efgh$, we have a normal force :—

$$P_n = P \sin \theta,$$

And a tangential force :—

$$P_t = P \cos \theta.$$

Now, the area $efgh$ $= \dfrac{\text{area } abcd}{\sin \theta} = \dfrac{A}{\sin \theta}$

If f_n and f_t be the normal and tangential stresses on the section $efgh$,

We have:— $$f_n = \frac{P_n}{\frac{A}{\sin\theta}} = \frac{P}{A}.\sin^2\theta = f.\sin^2\theta.$$

Similarly, we get:—$f = f.\sin\theta.\cos\theta.$

Strain.—When a piece of material, such as a bar of iron, is in tension or compression under the action of an applied force P, the bar will, in consequence, be lengthened or shortened by an amount depending on the extent to which it is *stressed*. The *ratio* which this *change* of length bears to the original length of the bar is called the *strain* due to P. Or in symbols,—

If, L = Original length of bar in inches.

And, l = Change of length of bar also in inches.

We have:— $$\text{Strain} = \frac{l}{L} \quad . \quad . \quad . \quad . \quad . \quad . \quad . \quad \text{(II)}$$

Since L and l are both actual lengths, measured by some common unit, the student should carefully note that strain, as thus defined, is merely an *abstract ratio*, and *not* a quantity, for it is independent of the units employed.

EXAMPLE I.—A tie-rod, 100 ft. long, is stretched $\frac{3}{4}$ of an inch by the action of a certain force; what is the strain?

Here, $L = 100 \times 12 = 1{,}200$ inches,

And, $l = 0{\cdot}75$ inch.

$$\therefore \quad \text{Strain} = \frac{0{\cdot}75}{1{,}200} = 0{\cdot}000625.$$

Coefficient, or Modulus of Elasticity.—Experiment has demonstrated that for most materials used in engineering there is a very simple law connecting stress and strain, which is fairly well defined within certain limits. The stress is proportional to the strain, so long as the stress does not exceed a certain value, which, of course, is different for different materials and for different qualities of the same material. For example, if the stress be doubled, the strain will be doubled, or if the stress be reduced to one-half, the strain will also be halved, and so on. The limit beyond which this law does not hold is termed the **Limit of Elasticity.** When this limit is exceeded, the strain increases at a much greater rate than the stress producing it. Within the limit of elasticity, the material returns to its original state when the load is removed; but when stressed

beyond this, the material does not do so, but retains a *permanent set*. In the following investigations the stress, in all cases, is assumed to be within the elastic limit:—

Consequently, $$\frac{\text{Stress}}{\text{Strain}} = \text{E (a constant)}. \quad . \quad . \quad . \quad . \quad \text{(III)}$$

This constant E is termed the **Modulus of Elasticity**, or more appropriately by some writers the **Coefficient of Elasticity.**

Another way of exhibiting the relation subsisting among the various quantities we have been discussing is to combine equations (I), (II), and (III) in such a way as to express the stress and strain in terms of loads and dimensions.

Thus, $$E = \frac{P}{A} \div \frac{l}{L};$$

Or, $$P\,L = A\,l\,E. \quad . \quad . \quad . \quad . \quad . \quad . \quad . \quad \text{(IV)}$$

Work done in Stretching a Bar.—Resilience.—If a load of *gradually* increasing amount be applied to a bar so as to stretch it, the amount of actual stretch, or elongation of the bar will, with the limitations already specified, be directly proportional to the load producing it. A diagram might, therefore, be drawn to represent graphically the work done in stretching the bar, as explained in Lecture II. of Volume I. The area of the diagram would represent the work done. The load will increase uniformly from 0 to P. The mean value of the force doing the work is, therefore, $\frac{1}{2}$ P, and the stretch or displacement is l. Hence, we have for the work done:—

$$W = \tfrac{1}{2}\,P\,l.$$

But from equations (I) and (III)—

$$P = fA, \qquad \text{and } l = \frac{fL}{E}.$$

$$\left.\begin{aligned} &\text{Hence,} \quad W = \frac{f^2}{E} \times \frac{A\,L}{2} \\ &\text{Or,} \quad W = \frac{f^2}{E} \times \tfrac{1}{2}\text{ volume of the bar.} \end{aligned}\right\} \quad . \quad . \quad . \quad . \quad \text{(V)}$$

The work done is therefore proportional to the volume of the bar, or to its weight.

When the bar is loaded to its elastic limit, or *proof stress*, as it is sometimes called, then the *work done* in stretching it is termed the **Resilience** of the bar, and the ratio $\frac{f^2}{E}$ is its **Modulus** or **Coefficient** of **Resilience.**

Example II.—What is the resilience of a material? If a wrought-iron tie bar, 5 feet long and 3 inches in diameter, has a limit of elasticity of 15 tons per square inch, and a modulus of elasticity of 30,000,000 lbs. per square inch, what is its resilience? (Take $\pi = \frac{22}{7}$.) (Adv. S. & A. Exam. 1893).

ANSWER.—$f = 15 \times 2240$ lbs., $E = 30{,}000{,}000$ lbs. per square inch, $A = \frac{1}{4} \times \frac{22}{7} \times 3^2$ square inches, and $L = 5$ feet.

$$\therefore \text{Resilience} = \frac{(15 \times 2240)^2}{30{,}000{,}000} \times \frac{\frac{11}{14} \times 3^2 \times 5}{2} = 665{\cdot}28 \text{ ft.-lbs.}$$

Sudden Pull, or Live Load.—We have just seen that a *constant* force of $\frac{1}{2}P$ lbs. acting through a distance of l feet will do the same amount of work in stretching a bar as would a load gradually increasing from zero to P lbs.; therefore, the strain produced by a *sudden pull* of $\frac{1}{2}P$ lbs. is the same as that due to P lbs. applied gradually. It follows, therefore, that if P be applied *suddenly*, but without initial velocity, the strain will be doubled, and the work done will be:—

$$W = P \times 2l = 2Pl \text{ ft.-lbs.}$$

Or, in words, the work done on the bar by a suddenly applied or *live load* P, is *four* times that done by a gradually applied or *dead load* of the same amount.

Shrunk Rings.—In the construction of built-up guns, the process consists in shrinking on a series of concentric rings, each ring griping the next inner one with a certain pre-determined tension.

The reason for this arrangement will be better understood when we come to deal with the strength of thick cylinders. The principles set forth in the preceding sections enable us to calculate the dimensions of rings to give a certain grip.

Let D = The external diameter of an inner ring.
,, d = The internal diameter of the next outer ring.
,, f = The required tension.

When the outer ring is shrunk on, its diameter is then D. The inner fibres of this ring are then stretched by an amount $\pi(D-d)$; and by definition, we have:—

$$\text{Strain} = \frac{\pi(D-d)}{\pi d} = \frac{D-d}{d}.$$

If E denote the modulus of elasticity of the material of the ring, then :—

$$E = \frac{\text{stress}}{\text{strain}} = \frac{f}{\frac{D - d}{d}}$$

Hence, $$d = D\left(\frac{E}{E + f}\right).$$

EXAMPLE III.—The external diameter of an inner ring is 20 inches. Work out the diameter which the outer ring must have in order to grip the inner one with an initial tension of 8 tons per sq. inch. Take the modulus of elasticity as 30,000,000.

ANSWER.—Here D = 20 inches, and $f = 8 \times 2240 = 17{,}920$ lbs. per sq. inch.

$$\therefore \qquad d = 20 \times \frac{30{,}000{,}000}{30{,}017{,}920} = 19{\cdot}98 \text{ inches.}$$

Strength of Thin Cylinders.—By *thin* cylinders are meant cylindrical vessels whose thickness is small compared with their diameter. The resistance which such vessels offer to forces tending to burst them, both longitudinally and circumferentially, is easily deduced as follows :—Consider a cylindrical ring, whose breadth is b inches, thickness t inches, and internal diameter is d inches. Let p denote the intensity of the internal pressure, in lbs. per sq. inch, tending to burst the ring, and f the induced stress within the material of the ring, also in lbs. per sq. inch.

Then the magnitude of the total internal force tending to tear asunder the ring at the ends of a diameter is $p\,d\,b$ lbs. And the resistance which the ring offers to this bursting force is $2\,t\,b\,f$ lbs.

These being equal, we have :—

$$2\,t\,b\,f = p\,d\,b \quad \therefore \quad f = \frac{p\,d}{2\,t}. \qquad . \quad . \quad . \quad \text{(VI)}$$

This result shows that the stress, in a circumferential direction, is independent of the length of the cylinder.

Whatever be the form of the ends of the cylinder—whether they be flat or hemispherical—the total force tending to cause rupture circumferentially is $p\,\frac{\pi}{4}\,d^2$ lbs. ; resisting this force, we have a ring of material whose total sectional area is $\pi\,d\,t$ sq. inches.

Let f_1 be the longitudinal stress due to the longitudinal bursting force; then the total resistance is $\pi\, d\, t\, f_1$ lbs.

And $$\pi\, d\, t\, f_1 = p\,\frac{\pi}{4}\,d^2$$

Hence, $$f_1 = \frac{p\,d}{4\,t}. \quad . \quad . \quad . \quad . \quad . \quad . \quad . \quad . \quad \text{(VII)}$$

From this we see that:—

$$f_1 = \tfrac{1}{2} f.$$

So that in a cylindrical boiler, which comes within the category of thin cylinders, the stress in a longitudinal direction is only one-half of the stress circumferentially.

Helical Seams.—If we made a boiler of rings, joined together circumferentially, then, so long as the strength of those joints was greater than one-half that of the solid plate, the boiler would still be as strong as one without joints, because the solid plate longitudinally would still be weaker than the circumferential joints. When, instead of solid rings, these are made up of pieces joined together longitudinally, it is obvious that the strength of the boiler is determined entirely by that of its longitudinal joints, unless the circumferential joints are less than half as strong.

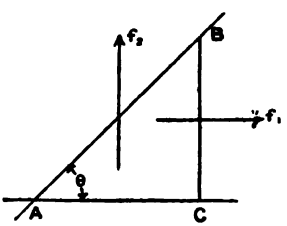

ILLUSTRATING STRESS ON HELICAL SEAMS.

As a compromise, it has been proposed to have, instead of circumferential and longitudinal joints, one continuous seam running spirally, called a helical joint.

Let the accompanying figure represent a portion of such a boiler flattened out. A B is the helical seam, which, when flattened out, becomes a straight line, making the angle θ with the longitudinal direction. The longitudinal and circumferential stresses are represented by f_1 and f_2 respectively. The intensities of those stresses on A B being denoted by f_1' and f_2', we have:—

$$f_1' \times \text{A B} = f_1 \times \text{B C}; \qquad \text{and } f_2' \times \text{A B} = f_2 \times \text{A C}.$$

$$\therefore \qquad f_1' = f_1 \sin\theta; \qquad \text{and } f_2' = f_2 \cos\theta.$$

Resolving f_1' and f_2' normally to A B, we have, for the total normal stress:—

$$f_n = f_1' \sin\theta + f_2' \cos\theta$$

$$,, = f_1 \sin^2\theta + f_2 \cos^2\theta.$$

But, $$f_1 = \tfrac{1}{2} f_2.$$

$\therefore$ $$f_n = \tfrac{1}{2} f_2 \sin^2\theta + f_2 \cos^2\theta.$$

Or, $$\frac{f_n}{f_2} = 1 - \tfrac{1}{2}\sin^2\theta.$$

Let, $$n = \frac{\text{B C}}{\text{A C}};$$

Then, $$\sin^2\theta = \frac{\text{B C}^2}{\text{A B}^2} = \frac{\text{B C}^2}{\text{B C}^2 + \text{A C}^2} = \frac{n^2}{n^2+1}$$

Hence, $$\frac{f_n}{f_2} = 1 - \tfrac{1}{2}\cdot\frac{n^2}{n^2+1} = \frac{n^2+2}{2n^2+2} \quad . \quad . \quad . \quad . \quad \text{(VIII)}$$

For example, if $n = 1$, *i.e.*, $\theta = 45°$,

Then, $$\frac{f_n}{f_2} = \frac{3}{4}.$$

That is to say, that the normal stress on a spirally-running joint, making an angle of 45° with the axis of the boiler, would be three-fourths of that on a longitudinal joint. With joints of equal efficiency, therefore, the helical seam would be 33·3 per cent. stronger than the longitudinal one.

Strength of Thick Cylinders.—When the thickness of a cylindrical vessel, subjected to internal pressure, is *not* small in comparison with its internal diameter, the problem requires to be treated differently.

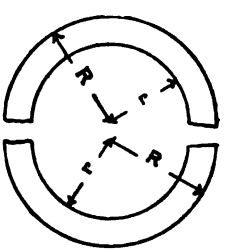

ILLUSTRATING STRAIN IN THICK CYLINDERS.

A complete determination of the strength of thick cylinders of all proportions is not an easy matter; and as for an *accurate* solution of the problem, the thing is simply impossible.

For moderate proportions of cylinders, such as are used in hydraulic appliances, the following demonstration yields results fairly substantiated by practice.

If such a cylinder were to give way under internal pressure, the plane of rupture would evidently contain the axis of the cylinder; whilst the rupture itself would appear as shown in the accompanying figure. From this figure it is clear that the circumferential *stretch* is the same from the inner to the outer surface. Now, remembering the definition of strain previously given, it is obvious that in this case, the strain in any cylindrical

layer within the material will be inversely as its radius; and since, within the elastic limit, the stress is proportional to the strain, it follows that the stress on any layer is also inversely as the radius of that layer:—

Let f = Stress at inner surface at distance r, from axis of cylinder.
" x = Radius of any layer within cylinder thickness.
" dx = The thickness of elementary layer.

Then the stress on the material at radius x, will be $f\frac{r}{x}$, and the total resistance per unit length of the elementary hoop is $2fr.\frac{dx}{x}$.

The total resistance of the cylinder is, therefore:—

$$= 2fr\int_r^R \frac{dx}{x}$$

$$= 2fr\log_e\frac{R}{r}.$$

But the total bursting force within the cylinder, per unit of length, is $2pr$, where p is the difference of the internal and external pressures.

Hence, equating these expressions for equal and opposite forces, we have:—

$$2pr = 2fr\log_e\frac{R}{r}.$$

$$\frac{p}{f} = \log_e\frac{R}{r}. \quad . \quad . \quad . \quad . \quad . \quad . \quad . \quad . \quad . \quad \text{(IX)}$$

The logarithms here required are hyperbolic.

Equation (IX) is not in a convenient form for application, because the ratio $\frac{R}{r}$ involves the quantity which is required; but a very simple and useful formula, quite accurate enough for most practical purposes, may be obtained as follows:—

For values of $\frac{R}{r}$ less than 2, $\log_e\frac{R}{r} = \frac{2(R-r)}{R+r}$, very approximately.

Making this substitution in (IX), we have:—

$$\frac{p}{f} = \frac{2(R-r)}{R+r}.$$

Whence,

$$\frac{R}{r} = \frac{2f+p}{2f-p}. \quad . \quad . \quad . \quad . \quad . \quad . \quad . \quad \text{(IXa)}$$

In practical calculations, the quantity usually required is the thickness of the cylinder; calling this t, we get:—

$$t = R - r$$
$$= \left(\frac{2f + p}{2f - p}\right) r - r$$
$$= \frac{2pr}{2f - p}.$$

Or, $$t = \frac{pd}{2f - p}. \quad \ldots \ldots \ldots \ldots \quad (X)$$

Where d = internal diameter of cylinder.

EXAMPLE IV.—The internal diameter of an hydraulic cylinder is 8 inches, and the ultimate tensile strength of the material of which it is made is 16,000 lbs. per sq. inch. What thickness of metal would be required in the sides of such a cylinder if the metal be not stressed beyond one-sixth of its ultimate strength, the water being under a pressure of 2000 lbs. per sq. inch? Prove the formula which you employ. (Hons. S. & A. Exam., 1889.)

ANSWER.—Here $f = \frac{1}{6} \times 16{,}000$; $p = 2000$; and $d = 8''$. Substituting these values in equation (X), we have:—

$$t = \frac{2000 \times 8}{2 \times \frac{1}{6} \times 16{,}000 - 2000} = 4{\cdot}8 \text{ inches.}$$

If formula (IX) be used, then:—

$$\log_e \frac{R}{r} = \frac{p}{f} = \frac{2000}{\frac{1}{6} \times 16{,}000} = 0{\cdot}75.$$

Or, $$\log_{10} \frac{R}{r} = 0{\cdot}75 \times {\cdot}4343 = {\cdot}326.$$

Therefore, $$\frac{R}{r} = 2{\cdot}12.$$

And, $$t = R - r = 4{\cdot}48 \text{ inches.}$$

Strength of Suspended Chains and Wires.—When a uniformly heavy chain or wire is suspended between two points, to find the equation to the curve in which it hangs, and the tension at any point. Let T be the tension at any point P; and H, that at the lowest point O. If W be the weight of the part O P of the chain, it is evident that O P will be in equilibrium under

the action of three forces—the tensions at O and P and its own weight W, acting through its centre of gravity. These three forces, therefore, must pass through some point K, in Ox, such that K P will be a tangent to the curve at the point P. Let the curve be referred to the co-ordinate axes, Ox, Oy, and let O N $= x$, and N P $= y$, O P $= s$. Also let w be the weight of a unit length of chain, and for H write $m\,w$. Resolving vertically and horizontally, we get:—

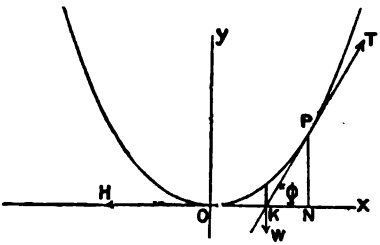

ILLUSTRATING STRENGTH OF SUSPENDED CHAINS.

$$T \sin \varphi = W = s\,w. \quad T \cos \varphi = H = m\,w.$$

Hence, $\tan \varphi = \dfrac{s}{m}$; or, $\dfrac{dy}{dx} = \dfrac{s}{m}$. . . . . (1)

But, $$\frac{dy}{ds} = \sin \varphi = \frac{1}{\operatorname{cosec} \varphi} = \frac{1}{\sqrt{\cot^2 \varphi + 1}} = \frac{s}{\sqrt{m^2 + s^2}}$$

$$\therefore \quad dy = \frac{s \,.\, ds}{\sqrt{m^2 + s^2}}.$$

Integrating this expression, we have:—

$$y = \sqrt{m^2 + s^2} + C.$$

To find the value of the constant C, we know that $s = 0$, when $y = 0$.

$$\therefore \quad 0 = m + C,$$

Or, $$C = -m.$$

So that, $$y + m = \sqrt{m^2 + s^2}.$$

and, therefore, $$s = \sqrt{(y+m)^2 - m^2}.$$

Substituting this value of s in (1), and inverting:—

$$\frac{dx}{dy} = \frac{m}{\sqrt{(y+m)^2 - m^2}}.$$

Multiplying each side by dy, and integrating, we get:—

$$x = m \,.\, \log_e \left\{(y+m) + \sqrt{(y+m)^2 - m^2}\right\} + C.$$

When $x = 0$, $y = 0$, then:—$C = -m \,.\, \log_e m$.

Hence, $$x = m \,.\, \log_e \left\{ \frac{y+m) + \sqrt{(y+m)^2 - m^2}}{m} \right\} \quad . \; . \quad (2)$$

Equation (2) is sometimes useful in the solution of problems. In order to get the equation to the curve in which the chain hangs, or, in other words, the relation between x and y, we write (2) as follows :—

$$\frac{x}{m} = \log_e \left\{\left(\frac{y+m}{m}\right) + \sqrt{\left(\frac{y+m}{m}\right)^2 - 1}\right\}$$

That is,
$$e^{\frac{x}{m}} = \left(\frac{y+m}{m}\right) + \sqrt{\left(\frac{y+m}{m}\right)^2 - 1}\,; \quad . \quad . \quad . \quad . \quad (3)$$

Where e is the base of the Napierian or hyperbolic logarithms.

Now, since :—

$$\left\{\left(\frac{y+m}{m}\right) + \sqrt{\left(\frac{y+m}{m}\right)^2 - 1}\right\} \cdot \left\{\left(\frac{y+m}{m}\right) - \sqrt{\left(\frac{y+m}{m}\right)^2 - 1}\right\} = 1$$

$$\therefore \left\{\left(\frac{y+m}{m}\right) - \sqrt{\left(\frac{y+m}{m}\right)^2 - 1}\right\} = \frac{1}{\left\{\left(\frac{y+m}{m}\right) + \sqrt{\left(\frac{y+m}{m}\right)^2 - 1}\right\}}$$

$$= \frac{1}{e^{\frac{x}{m}}}.$$

Hence,
$$e^{-\frac{x}{m}} = \left(\frac{y+m}{m}\right) - \sqrt{\left(\frac{y+m}{m}\right)^2 - 1}. \quad . \quad . \quad . \quad . \quad (4)$$

Now, adding (3) and (4) and reducing, we have finally :—

$$\left.\begin{aligned} y &= \frac{m}{2}\left\{e^{\frac{x}{m}} + e^{-\frac{x}{m}} - 2\right\} \\ \text{Or,} \quad y &= \frac{m}{2}\left\{e^{\frac{x}{2m}} - e^{-\frac{x}{2m}}\right\} \end{aligned}\right\} \quad . \quad . \quad . \quad . \quad . \quad (\text{XI})$$

The curve whose equation is (XI) is called a *catenary*.

To find T, the tension at any point, we have :—

$$\mathrm{T} = \frac{s\,w}{\sin\varphi} = s\,w \div \frac{s}{\sqrt{s^2 + m^2}}$$

$$= w \,.\, \sqrt{s^2 + m^2}.$$

But
$$\sqrt{s^2 + m^2} = y + m.$$

$$\therefore \quad \mathrm{T} = w\,(y + m). \quad . \quad . \quad . \quad . \quad . \quad . \quad . \quad . \quad (\text{XII})$$

When the curve is very flat, as in the case of telegraph wires, then $s = x$ approximately, and (1) becomes $\frac{dy}{dx} = \frac{x}{m}$.

Multiplying by dx and integrating, we get :—

$$y = \frac{x^2}{2m} \quad . \quad . \quad . \quad . \quad . \quad . \quad . \quad \text{(XIII)}$$

This requires no correction, because x and y vanish together.

EXAMPLE V.—A telegraph wire, which weighs $\frac{1}{10}$ of a lb. per yard, is stretched between poles on level ground, so that the greatest dip of the wire is 3 feet. Find approximately the distance between the poles when the tension at the lowest point of the wire is 140 lbs. (Hons. S. and A. Exam., 1891.)

ANSWER.—Here, $H = 140$, $y = 3$ ft., and $w = \frac{1}{30}$; and since :—

$$H = m\,w$$

$$\therefore \qquad 140 = m \times \frac{1}{30}.$$

$$\text{Or,} \qquad m = 4200.$$

Putting these values of y and m in equation (XIII), it becomes :—

$$3 = \frac{x^2}{2 \times 4200}.$$

$$\therefore \qquad x = \sqrt{3 \times 2 \times 4200} = 158{\cdot}7 \text{ ft.}$$

Distance between poles :—

$$= 2\,x = 2 \times 158{\cdot}7 = 317{\cdot}4 \text{ ft.}$$

If the more exact equation (2) be used, then :—

$$2\,x = 2 \times 4200 \times \log_e \left\{ \frac{4203 + \sqrt{4203^2 - 4200^2}}{4200} \right\}$$

$$\text{,,} \quad = 8400 \times \log_e \frac{218}{210}$$

$$\text{,,} \quad = 8400 \times 0{\cdot}0374 = 314{\cdot}16 \text{ ft.}$$

LECTURE XXIX.—QUESTIONS.

1. What do you understand by the terms *strain*, *stress*, and *modulus of elasticity*? A tie rod 100 feet long, and of 2 square inches sectional area, is stretched three-quarters of an inch under a tension of 32,000 lbs. What is the intensity of the stress, the strain, and the modulus of elasticity under these circumstances? (S. and A. Exam., 1888.) *Ans.* 16,000 lbs. per square inch; 0·000625; 25,600,000.

2. A ship is moored by two cables of 90 feet and 100 feet in length respectively. The first cable stretches $2\frac{5}{8}$ inches, and the second stretches 3 inches, under the pull of the ship; find the strain of each cable. (S. and A. Exam., 1889.) *Ans.* 0·00243; 0·0025.

3. Define the term *Resilience*. Show that the work done on a material by a *live load* is four times that done by an equal *dead load*. A wrought-iron tie rod 20 feet long and ·5 square inch cross sectional area bears a dead load of 5,000 lbs. Find the work done on stretching the rod by this load. What live load would produce an instantaneous elongation of another $\frac{1}{10}$ inch? Take E = 30,000,000. *Ans.* 33·$\dot{3}$ ft.-lbs.; 3,125 lbs.

4. A rod of iron 25 feet long and 2 square inches cross sectional area checks a weight of 80 lbs., which falls from a height of 20 feet before beginning to strain it. Find the greatest stress and strain produced. Take E = 25,000,000. *Ans.* 39,960 lbs. per square inch; ·0016.

5. If the modulus of elasticity of a piece of steel in lbs. per square inch is 32,000,000, how much would a bar $\frac{3}{4}$ of an inch in diameter and 25 inches long extend under a load of 10 tons? If its limit of elasticity is 21 tons per square inch, what is its resilience? (S. and A. Exam., 1894.)

6. What is the resilience of a bar? A bar of steel is $\frac{7}{8}$ inch in diameter, and 30 inches in length, and is under a tensile pull of 10 tons, what is the work stored up in the bar, the modulus of elasticity being 32,000,000 lbs. per square inch? (S. and A. Exam., 1895.)

7. Built-up guns are made of concentric rings, the outer hoops, or rings, being shrunk or forced upon inner tubes with a regulated tension. Supposing the external diameter of the inner tube to be 12 inches, and that the substance of its covering hoop is to have given to it an initial grip of 4 tons per square inch of its sectional area; the exterior diameter of this second hoop is 18 inches, and is to be covered with a third hoop, having an initial grip of 8 tons per square inch of its sectional area; will you work out in arithmetic the difference of dimensions that will afford the above conditions?

8. Prove that when a thin spherical shell is exposed to the bursting pressure of gas or liquid the stress in the material is half as great as that within the curved surface of a thin cylindrical shell exposed to the like pressure, each shell being of the same thickness and diameter. (S. and A. Exam., 1891.)

9. A long thin pipe of given internal radius is subjected to fluid pressure; find the tension of the material of the pipe. If the internal radius of the pipe is 6 inches, and the thickness of the pipe 0·5 inch, what fluid pressure per square inch would increase the radius of the pipe by 0·001 inch? The modulus of elasticity being 20,000,000, and the elasticity of the material being supposed to continue perfect. *Ans.* 277·7 lbs. per square inch.

10. A *steel* hydraulic cylinder, 10 feet long and 6 inches in diameter, acts as a brake on a lift. It has a movable piston fitted with a spring valve, the cylinder being full of liquid when the lift is at its highest position, and the piston and rod at the end of the stroke inside the cylinder. It was found that when the lift began to descend the internal pressure was 1,000 lbs. per square inch, which gradually rose to 2,000 lbs. when the piston had travelled 9 feet. Treating the cylinder as a thin one, what would be the law of variation of thickness at different points? Prove the formula. (S. and A. Hons. Exam., 1890.)

11. A uniformly heavy chain is suspended from two given points: find the equation to the curve in which it hangs, and the tension at any point of the curve. (S. and A. Hons. Exam., 1892.)

12. Prove that the tendency of a thin cylindric pipe to burst laterally (neglecting the strength of flanges, &c.) is twice as great as to burst endwise.

A wrought-iron pipe is 2 feet diameter, ½ inch thick, its working stress is 5 tons to the square inch, but strength of plate is diminished 30 per cent. because of riveted joint. What is the working pressure? What head of water does this correspond to? (S. & A. Adv. Exam., 1897.)

13. Prove the law for the tensile stress produced in a thick cylinder by internal fluid pressure. Describe how we attempt by chilling to give maximum strength. (Hons. S. & A. Exam., 1897.)

14. A steel tube 5 inches internal and 7 inches external diameter has steel strip wound on it to the external diameter of 12 inches under a constant winding tensile stress of 15 tons per square inch. What is the stress at any place in the solid metal or the winding? (S. & A. Hons. Exam., Part II., 1898.)

LECTURE XXX.

CONTENTS.—Torsional Strength of Shafts—Examples I., II., and III.—Strength of Shafts subjected to Combined Twisting and Bending—Theorem—Examples IV. and V.—Stiffness of Shafts—Angle of Twist—Example VI.—Questions.

Torsional Strength of Shafts.—In order to transmit energy through a shaft, the driving force must be applied at some distance from its centre. The driving force and its effective leverage, therefore, constitute what is termed a **Turning** or **Twisting Moment** (T.M.) which puts the shaft in a state of twist or torsion. The tendency of a purely torsional moment applied to a shaft is to cause the shaft to shear in planes normal to its axis, and this has to be met by the shearing resistance of the material, which resistance must, of course, be of the nature of a moment. The resistance the shaft offers to twisting we term its **Torsional Resistance** (T.R.); and as this balances the turning moment, we have :—

$$\text{T.M.} = \text{T.R.}$$

We have now to find the value of T.R., as depending on the material and dimensions of the shaft, and shall confine ourselves to shafts of circular section—solid and hollow. Suppose the accompanying figure to represent an end view of a shaft; and suppose A B and *a b* to have been parallel diameters of two sections very near to each other when the shaft was at rest; then, when the shaft is at work transmitting energy, the diameters, A B and *a b*, will no longer be parallel, but will make an angle with each other, as shown. A longitudinal section, through the axis of a shaft, which is a plane when the shaft is at rest, thus becomes a screw surface when the shaft is working. We shall have occasion later to measure this angle of twist; but in the meantime we are mainly concerned with the distribution of shearing stress within the shaft.

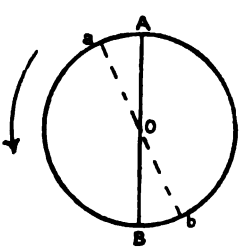

ILLUSTRATING STRAIN IN A SHAFT.

Looking at the figure, we easily see that the *strain* in any ring of fibres must be proportional to the arc of this ring

which is included between the diameters A B and $a\,b$, when these are twisted out of parallelism by the turning moment. Within the elastic limit of the material, therefore, it follows that the shearing *stress* in any ring of fibres is proportional to the radius of that ring.

Therefore, let f = the greatest shearing stress, in lbs. per sq. inch, permissible in the material of the shaft.

D = the outside diameter,

d = the inside diameter of the shaft, both in inches.

And x = the radius of *any* ring of fibres within the material of the shaft.

Then the shaft must be so proportioned that f shall be the value of the stress in its outermost fibres which are $\frac{1}{2}$ D inches from the centre. Consequently, from what has already been said, we have :—

$$\text{Stress at } x = \frac{x}{\frac{1}{2}\,\mathrm{D}}\,f = \frac{2\,x}{\mathrm{D}}\,f.$$

Consider, now, the ring of fibres at x inches from the shaft centre, whose radial thickness is $d\,x$ inches. The sectional area of this elementary ring will $= 2\,\pi\,x\,d\,x$ sq. inches; and its resistance to shearing will be

$$2\,\pi\,x\,d\,x \times \frac{2\,x}{\mathrm{D}}\,f \text{ lbs.} = \frac{4\,\pi\,f}{\mathrm{D}}\,x^2\,d\,x \text{ lbs.}$$

Now, the leverage at which this resisting ring of fibres acts, is x inches; therefore, its *moment* of resistance is $\frac{4\,\pi\,f}{\mathrm{D}}\,x^2\,d\,x \times x$, or $\frac{4\,\pi\,f}{\mathrm{D}}\,x^3\,d\,x$ inch-lbs.

Hence, summing up the moments of resistance of all such elementary rings which go to make up the shaft, we get:—

$$\text{T.R.} = \frac{4\,\pi\,f}{\mathrm{D}}\int_{\frac{1}{2}d}^{\frac{1}{2}\mathrm{D}} x^3\,d\,x,$$

$$\text{,,} = \frac{4\,\pi\,f}{\mathrm{D}}\left\{\frac{(\frac{1}{2}\,\mathrm{D})^4}{4} - \frac{(\frac{1}{2}\,d)^4}{4}\right\}$$

$$\text{,,} = \frac{\pi}{16}\,f\left(\frac{\mathrm{D}^4 - d^4}{\mathrm{D}}\right).$$

Hence, for hollow shafts, we have:—

$$\text{T.R.} = \frac{\pi}{16}\left(\frac{D^4 - d^4}{D}\right) f \quad . \quad . \quad . \quad . \quad . \quad . \quad \text{(I)}$$

For solid shafts, we make $d = 0$, and get:—

$$\text{T.R.} = \frac{\pi}{16} D^3 f \quad . \quad . \quad . \quad . \quad . \quad . \quad . \quad . \quad \text{(II)}$$

It is instructive to compare the torsional resistances of solid and hollow shafts of the same weight and material. For this purpose let D_1 be the outer diameter of hollow shaft.

Then, if we neglect couplings, and consider the shafts to be of equal length, the weights will simply be proportional to their sectional areas; *i.e.*:—

$$\frac{\text{Weight of hollow shaft}}{\text{Weight of solid shaft}} = \frac{D_1^2 - d^2}{D^2}.$$

For equal weights, this ratio is unity; therefore we have the relation:—

$$D^2 = D_1^2 - d^2$$

Or,

$$D = \sqrt{D_1^2 - d_1^2}.$$

Now, we have from equations (I) and (II):—

$$\frac{\text{T.R. of hollow shaft}}{\text{T.R. of solid shaft}} = \frac{D_1^4 - d^4}{D_1 \times D^3} = \frac{D_1^2 + d^2}{D_1 \times D} \times \frac{D_1^2 - d^2}{D^2}$$

$$\text{"} \qquad \text{"} \qquad = \frac{D_1^2 + d^2}{D_1 \times D} = \frac{D_1^2 + d^2}{D_1 \times \sqrt{D_1^2 - d^2}}.$$

It will simplify matters if we put $d = x \times D_1$, where x is a proper fraction, we then have:—

$$\frac{\text{T.R. of hollow shaft}}{\text{T.R. of solid shaft}} = \frac{1 + x^2}{\sqrt{1 - x^2}}.$$

For example, let $x = \frac{1}{2}$, then:—

$$\frac{1 + x^2}{\sqrt{1 - x^2}} = \frac{1 + \frac{1}{4}}{\sqrt{1 - \frac{1}{4}}} = \frac{5}{2\sqrt{3}} = 1{\cdot}443.$$

This result shows that for the same length and weight, the hollow shaft having outer and inner diameters in the proportion of 2 to 1 will be 44·3 per cent. stronger than the solid one.

The turning moment driving a shaft may either be uniform or variable in amount. Shafts driven by means of gearing, and revolving at a uniform speed, are generally considered as cases

of uniform turning moment. As a typical example of variable turning moment, we have the case of the steam engine crank-shaft, where both the driving force of the steam on the piston and its effective leverage are continually varying throughout the stroke.

When the turning moment is uniform—that is, when the shaft revolves uniformly at n revolutions per minute, and transmits energy at the rate of so many H.P., this is all the data we require to know in order to estimate T. M. We have already seen (see Vol. I., Lect. III.) that the work done by a turning couple in one minute is equal to the magnitude of the turning couple multiplied by its angular displacement in the same time. Now our turning couple, or turning moment, as we call it, is T.M. inch-lbs., or $\frac{1}{12}$ T.M. foot-lbs., and the angular velocity of our shaft is $n \times 2\pi$ radians per minute.

Therefore, the

$$\text{Work done} = \frac{\text{T.M.}}{12} \times 2\pi n \text{ ft.-lbs. per minute}$$

And the $$\text{H.P.} = \frac{\frac{\text{T.M.}}{12} \times 2\pi n}{33{,}000} = \frac{n \times \text{T.M.}}{63{,}024}.$$

$$\therefore \qquad \text{T.M.} = 63{,}024 \,.\, \frac{\text{H.P.}}{n} \,. \qquad \ldots\ldots \qquad \text{(III)}$$

EXAMPLE I.—Find the moment of resistance to torsion of a hollow shaft. Compare the strengths to resist torsion of a solid and hollow shaft of the same length and weight, the extreme diameter of the hollow shaft being double its internal diameter. A hollow shaft, the external and internal diameters of which are 20 inches and 8 inches respectively, runs at 70 revolutions per minute, with a surface stress of 6,000 lbs. per square inch; find the twisting moment and the horse-power transmitted. (S. & A. Hons. Exam., 1895.)

ANSWER.—The first two parts of this question have already been answered in the text.

With regard to the last part, we are asked to find the values of T.M. and H.P., being given:—

$D_1 = 20$ inches. $\qquad f = 6000$ lbs. per sq. in.
$d = 8$ inches. $\qquad n = 70$ per min.

Since $$\text{T.R.} = \text{T.M.}$$

$$\text{,,} = \frac{\pi}{16} \cdot \frac{D_1^4 - d^4}{D_1} \cdot f.$$

$$\therefore \qquad \text{T.M.} = \frac{3{\cdot}1416}{16} \times \frac{20^4 - 8^4}{20} \times 6000.$$

$$\text{,,} \quad = 9{,}183{,}525 \text{ inch-lbs.}$$

and

$$\text{H.P.} = \frac{\text{T.M.} \times n}{63{,}024}$$

$$\text{,,} \quad = \frac{9{,}183{,}525 \times 70}{63{,}024}$$

$$\text{,,} \quad = 10{,}200.$$

EXAMPLE II.—If a steel shaft revolving at 60 revolutions per minute be required to transmit 220 horse-power, what should be its diameter so that the maximum stress produced in it may not exceed one-fifth of that at the elastic limit? The elastic limit in torsion is 18 tons per sq. inch. Prove any formula you may employ. (S. & A. Hons. Exam., 1894.)

ANSWER.—Combining formulæ (II) and (III) we have :—

$$\text{T.R.} = \text{T.M.},$$

i.e.,

$$\frac{\pi}{16} D^3 f = 63{,}024 \times \frac{\text{H.P.}}{n}.$$

$$\therefore \qquad D = 68{\cdot}5 \sqrt[3]{\frac{\text{H.P.}}{n f}}. \quad . \quad . \quad . \quad \text{(IV)}$$

Here, H.P. = 220. $n = 60$.

And, $f = \frac{1}{5} \times 18 \times 2240 = 8064$ lbs. per sq. in.

$$\therefore \qquad D = 68{\cdot}5 \times \sqrt[3]{\frac{220}{60 \times 8064}} = 5{\cdot}27 \text{ inches.}$$

In cases where the turning moment exerted on a shaft varies, it is, of course, necessary that the shaft should be of strength sufficient to withstand safely the maximum value of T.M. So that in dealing with an example like that of the steam engine crank-shaft we take as the turning force the product of the maximum effective steam pressure on the piston into the piston area; and for the leverage we take the crank radius, although this is not quite accurate; because, if the crank be driven by means of a connecting-rod, the virtual leverage of the steam force at a certain point in the stroke exceeds that of the crank radius by an amount depending on the relative lengths of the crank and connecting-rod.

But on the other hand, the effective steam pressure on the piston is, as a rule, much below its maximum value when the piston reaches the point of greatest leverage. On the whole, therefore, it is quite accurate enough for all practical purposes to estimate the maximum turning moment in the way we have indicated.

Thus, Let p = Greatest effective steam pressure acting on the piston, in lbs. per sq. inch.

„ A = Area of piston, in sq. inches.

„ r = Crank-radius, in inches.

Then, max. T.M. = p A r inch-lbs.

By *effective* steam pressure, we mean the *difference* between the pressures behind, and in front of, the piston.

EXAMPLE III.—Find the diameter of the crank-shaft for a horizontal engine which is to be worked with an effective mean steam pressure of 45 lbs. per square inch throughout the stroke, the diameter of the cylinder being 36 inches, the stroke 5 feet, and the working load being taken at $\frac{1}{6}$ of the breaking load. The shaft is to be of wrought iron, such that a 1-inch shaft will break with the torsion produced by 800 lbs. acting at the end of a 12-inch lever. (S. & A. Hons. Exam.)

ANSWER.—Let f_B be the breaking stress of the experimental shaft, then the working stress in the crank shaft, according to the question, will be $\frac{1}{6} f_B$.

To find the value of f_B we are given that when T.M. = 800 × 12 inch-lbs., and D = 1″, fracture takes place. From these data, therefore, we deduce :—

$$f_B = \frac{800 \times 12}{\frac{\pi}{16} \times 1^3} = \frac{800 \times 12}{\frac{\pi}{16}} \text{ lbs.}$$

The area of a 36-inch piston = 1017·87 square inches, and r is 30 inches.

$$\therefore \quad \text{Max. T.M.} = 45 \times 1017{\cdot}87 \times 30 \text{ inch-lbs.}$$

$$\text{Also,} \quad \text{„} \quad = \frac{\pi}{16} D^3 f.$$

$$\therefore \quad D^3 = \frac{45 \times 1017{\cdot}87 \times 30}{\frac{\pi}{16} f};$$

but, $$f = \tfrac{1}{6} f_B = \frac{800 \times 2}{\frac{\pi}{16}}.$$

Hence, $$D = \sqrt[3]{\frac{45 \times 1017{\cdot}87 \times 30}{800 \times 2}},$$

$$,, \quad = 9{\cdot}5 \text{ inches, nearly.}$$

Strength of Shafts subjected to combined Twisting and Bending.—In Example III. the diameter of the shaft has been calculated as for a purely twisting moment. But in no case of a shaft being driven by a crank is the effect of the load quite so simple as this. Besides the turning moment, which we have already seen how to deal with, there is always in action a *bending* moment of greater or less magnitude depending on the engine arrangement. The worst case is that in which the crank is overhung. When this is so, the bending moment is caused by the load on the piston acting along a line (the centre line of the cylinder) at a certain distance from the shaft bearing nearest to the crank.

Let l = the distance between the centre line of the cylinder and the middle of the nearest shaft bearing, in inches; and
p and A = (as before) the effective steam pressure and piston area respectively.

Then the magnitude of the bending moment which we have now to take into account is

$$\text{B.M.} = p\,A\,l \text{ inch-lbs.}$$

This bending moment is balanced by the moment of resistance of the shaft, which, as will be shown in the next lecture, is

$$\text{M.R.} = \frac{\pi}{32} D^3 f_t\,;$$

Where, D = diameter of the shaft journal, in inches,
And, f_t = the tensile stress in the outer fibres of the journal, in lbs. per sq. inch.

Hence, we see that when a crank-shaft is being turned by the steam on the piston, it is subjected simultaneously to a shearing stress of intensity f_s, and a tensile stress of intensity f_t. The problem now before us is to combine these stresses so as to

obtain what is termed the *Equivalent* tensile or shearing stress; but in order to render all the steps in the process clear and intelligible, we require to demonstrate the following theorem :—

Theorem.—A shearing stress on any plane produces a shearing stress of equal intensity on planes at right angles to it.

Let A B C D be a rectangular block of material whose thickness is 1 inch perpendicular to the plane of the paper. And let f_s be the intensity of the shearing stress over the face whose edge is

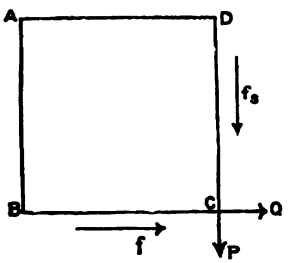

ILLUSTRATING SHEARING STRESS THEOREM.

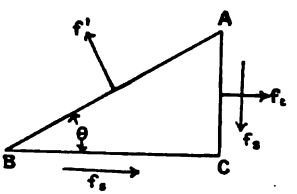

ILLUSTRATING EQUIVALENT TENSILE STRESS.

C D. It is easy to see that the total shearing force on the face C D which tends to pull that face parallel to itself, must be accompanied by a similar effect on the face B C in order that the block may not be turned around A. To find the relation between those forces, take moments about A, and we get :—

$$P \times AD = Q \times AB.$$

Or, $$(f_s \,.\, CD) \times BC = (f \,.\, BC) \times CD.$$

$$\therefore \qquad f_s = f.$$

Hence, we see that the shearing stress induced in a shaft by the turning moment is accompanied by a shearing stress of equal intensity on planes at right angles to it; that is, parallel to the axis of the shaft.

In the right-hand figure let A C represent the edge of a small portion of a plane normal to the axis of the shaft, and B C that of another plane at right angles to A C. On the former of these planes there is a shearing stress of intensity f_s, due to the turning moment, and a direct tensile stress of intensity f_t, due to the bending moment acting on the shaft. By the theorem just proved, we also have on B C a shearing stress f_s. Let f' denote the intensity of a tensile stress, which, acting on a

plane A B inclined to A C and B C, would balance the stresses on these latter planes. As before, let the width of the three planes perpendicular to the plane of the paper be unity.

Resolving vertically and horizontally, we have :—

$$(f' \,.\, \mathrm{AB}) \cos\theta = (f_s \,.\, \mathrm{AC}),$$

and $$(f' \,.\, \mathrm{AB}) \sin\theta = (f_s \,.\, \mathrm{BC}) + (f_t \,.\, \mathrm{AC}).$$

From the first of these equations we get :—

$$\frac{f'}{f_s} = \frac{\frac{\mathrm{AC}}{\mathrm{AB}}}{\cos\theta} = \frac{\sin\theta}{\cos\theta} = \tan\theta, \quad . \quad . \quad . \quad . \quad (1)$$

and from the second :—

$$f' = \frac{\frac{\mathrm{BC}}{\mathrm{AB}}}{\sin\theta} \cdot f_s + \frac{\frac{\mathrm{AC}}{\mathrm{AB}}}{\sin\theta} \cdot f$$

$$\text{,,} = \frac{\cos\theta}{\sin\theta} f_s + \frac{\sin\theta}{\sin\theta} f_t.$$

$$\text{,,} = f_s \cot\theta + f_t.$$

Or, $$\frac{f' - f_t}{f_s} = \cot\theta. \quad . \quad . \quad . \quad . \quad . \quad . \quad . \quad . \quad . \quad . \quad (2)$$

Multiplying together (1) and (2), we get :—

$$\frac{f'}{f_s} \cdot \frac{f' - f}{f_s} = 1.$$

$$\therefore \qquad f'(f' - f) = f_s^2.$$

Which on being solved for f' gives :—

$$f' = \frac{f_t}{2} + \sqrt{\frac{f_t^2}{4} + f_s^2} \quad . \quad . \quad . \quad . \quad . \quad . \quad (\mathrm{V})$$

We take the positive sign in the solution of this quadratic equation, for obviously f' is greater than $\frac{1}{2} f_t$.

Being now in possession of the relation subsisting among the stresses, we next have to express these in terms of the T.M. and B.M. :—

Since $$\text{T.M.} = \frac{\pi}{16} D^3 f_s.$$

And $$\text{B.M.} = \text{R.M.} = \frac{\pi}{32} D^3 f_t.$$

Hence, $$f_s = \frac{\text{T.M.}}{\frac{\pi}{16} D^3} \quad . \quad . \quad . \quad . \quad . \quad . \quad . \quad (3)$$

And $$f = \frac{\text{B.M.}}{\frac{\pi}{32} D^3} \quad . \quad . \quad . \quad . \quad . \quad . \quad . \quad (4)$$

In like manner, we must have:—

$$f' = \frac{\text{B.M.}}{\frac{\pi}{32} D^3}$$

where B.M.′ stands for the *equivalent* bending moment.

Making these substitutions, and reducing, (V) becomes:—

$$\text{B.M.}' = \tfrac{1}{2} \{\text{B.M.} + \sqrt{\text{B.M.}^2 + \text{T.M.}^2}\} \quad . \quad . \quad . \quad (\text{VI})$$

Now, if T.M.′ denotes the *equivalent* twisting moment, it easily follows from equations (3) and (4) that for equal intensities of stress we have:—

$$\text{T.M.}' = 2\ \text{B.M.}'$$

Hence, $$\text{T.M.}' = \text{B.M.} + \sqrt{\text{B.M.}^2 + \text{T.M.}^2} \quad . \quad . \quad . \quad (\text{VII})$$

It will be found that equation (VII), giving the so-called equivalent twisting moment, is the one most generally applied. It should be noted, however, that the stress concerned here is a *tensile* one and not a shear as in a proper twisting moment.

EXAMPLE IV.—Investigate an expression in terms of f_t, f', and f_s, which will give the resultant tensile stress, f', per square inch of section in a material which is subjected at the same time to a direct tensile stress of f_t lbs. per square inch, and to a shearing stress, f_s, lbs. per square inch. A bar of iron is at the same time under a direct tensile stress of 5,000 lbs. per square inch, and to a shearing stress of 3,500 lbs. per square inch. What would be the resultant equivalent tensile stress in the material? (S. & A. Hons. Exams., 1896.)

ANSWER.—The complete investigation referred to in the first part of this question is given in the text, and equation (V)

is the expression required. It only remains to find the numerical value of f', having given

$$f_t = 5{,}000 \text{ and } f_s = 3{,}500$$

$$\therefore \quad f' = \frac{5{,}000}{2} + \sqrt{\frac{5{,}000^2}{4} + 3{,}500^2}$$

$$\text{,,} = \mathbf{6{,}800 \text{ lbs. per sq. in. fully.}}$$

EXAMPLE V.—A wrought-iron shaft is subjected simultaneously to a bending moment of 8,000 inch-lbs., and to a twisting moment of 15,000 inch-lbs. Find the twisting moment equivalent to these two, and the least safe diameter of the shaft. The safe stress against shearing is to be taken at 8,000 lbs. per square inch. Prove clearly the formula you employ. (S. & A. Hons. Exam., 1890.)

ANSWER.—Here we have:—

$$\text{B.M.} = 8{,}000 \text{ inch-lbs.}$$

And $$\text{T.M.} = 15{,}000 \quad \text{,,}$$

Hence, by formula (VII) we get:—

$$\text{T.M.}' = 8{,}000 + \sqrt{8{,}000^2 + 15{,}000^2}$$

$$\text{,,} = \mathbf{25{,}000 \text{ inch-lbs.}}$$

To find the diameter of the shaft to withstand this T.M.′ with a shearing stress of not over 8,000 lbs. per square inch, we employ formula (II) making:—

$$\text{T.M.} = \text{T.R.} = \frac{\pi}{16} D^3 f.$$

$$\therefore \quad D = \sqrt[3]{\frac{\text{T.M.}'}{\frac{\pi}{16} \cdot f}} = \sqrt[3]{\frac{25{,}000}{\frac{3{\cdot}1416}{16} \times 8{,}000}} = \mathbf{2{\cdot}51 \text{ inches.}}$$

Stiffness of Shafts.—Angle of Twist.—We have already seen that the effect of a turning moment applied to a shaft is to twist one part relatively to another. Hitherto we have been dealing only with the resistance the shaft offers to being twisted—that is to say, we have been concerned only with the *strength* of the shaft without regard to the question of *stiffness*. In many cases

—especially in light machinery—the question of the stiffness of the shafting is of greater importance than that of strength.

The stiffness of a shaft is measured by the smallness of the angle of twist per unit length of the shaft.

Turning back to the figure illustrating strain in a shaft, let dl be the axial distance, in inches, between the two sections whose diameters are A B, $a\,b$, and let $d\theta$ be the circular measure of the angle between those diameters when the shaft is twisted; then the torsional, or shearing *strain* at the surface of the shaft, is

$$=\left(\frac{D}{2}\right)\times\frac{d\theta}{dl}.$$

D, as before, being the extreme diameter of the shaft in inches,

Let f = Surface stress in the material of the shaft in lbs. per sq. inch.

„ C = Modulus or coefficient of shearing elasticity or of rigidity in lbs. per sq. inch.

Then, since

$$C=\frac{\text{stress}}{\text{strain}}=\frac{f}{\left(\frac{D}{2}\right)\cdot\frac{d\theta}{dl}}.$$

$$\therefore \qquad d\theta=\frac{2f}{CD}\cdot dl.$$

Hence, for a shaft L inches long we have, by a simple integration, the angle of twist.

$$\theta=\frac{2f}{CD}\int_0^L dl=\frac{2fL}{CD}.$$

To express this result in terms of the twisting moment and the diameter of the shaft, we have :—

$$f=\frac{\text{T.M.}}{\frac{\pi}{16}D^3}\ \text{for solid shafts.}$$

And,

$$f=\frac{\text{T.M.}}{\frac{\pi}{16}\frac{D^4-d^4}{D}}\ \text{for hollow shafts.}$$

Making these substitutions and simplifying, we get :—

Angle of twist for solid shafts,

$$\left.\begin{aligned} \theta &= \frac{10{\cdot}2\,(\text{T.M.})\,\text{L}}{\text{C D}^4}\text{. radians.} \\ \text{Or,}\quad \theta^\circ &= \frac{584\,(\text{T.M.})\,\text{L}}{\text{C D}^4}\text{. degrees.} \end{aligned}\right\} \quad . \quad . \quad . \quad \text{(VIII)}$$

And, for hollow shafts,

$$\left.\begin{aligned} \theta &= \frac{10{\cdot}2\,(\text{T.M.})\,\text{L}}{\text{C}\,(\text{D}^4 - d^4)}\text{. radians.} \\ \text{Or,}\quad \theta^\circ &= \frac{584\,(\text{T.M.})\,\text{L}}{\text{C}\,(\text{D}^4 - d^4)}\text{. degrees.} \end{aligned}\right\} \quad . \quad . \quad . \quad . \quad \text{(IX)}$$

By the equations just established, we see that, while the strength of shafts vary as the *third* power of their diameters, their stiffness varies as the *fourth* power.

EXAMPLE VI.—Establish a formula for the moment of resistance to torsion of a solid shaft of circular section. The angle of torsion of a shaft is limited to 1° for each 10 feet of length ; find the diameter of a solid round shaft to transmit 100 H.P. at 50 revolutions per minute, the modulus of resistance to torsion being 10,000,000 lbs. per sq. inch. (S. & A. Hons. Exam., 1892.)

ANSWER :—

Here, $\theta = 1^\circ$ when, $\text{L} = 10 \times 12 = 120$ inches

And, $\text{C} = 10{,}000{,}000.$

Also, $$\text{T.M.} = 63{,}024 \times \frac{\text{H.P.}}{n} = 63{,}024 \times \frac{100}{50}$$

$$\text{,,} \quad = 126{,}048 \text{ inch-lbs.}$$

Now, applying formula (VIII) the given conditions are that:—

$$1^\circ = \frac{584 \times 126{,}048 \times 120}{10{,}000{,}000 \times \text{D}^4}$$

Hence, solving for D, we get :—

$$\text{D} = \sqrt[4]{\frac{584 \times 126{,}048 \times 120}{10{,}000{,}000}} = 5{\cdot}45 \text{ inches.}$$

LECTURE XXX.—QUESTIONS.

1. A 10-inch shaft has a 4-inch hole run through it; what fraction of its weight is removed? To what extent is its strength in resisting torsion affected? *Ans.* 16 per cent.; 2·5 per cent. nearly.

2. A hollow shaft is 10 inches external diameter and 4 inches internal diameter; compare its strength to resist torsion with that of a solid shaft of the same weight.

3. Cylindrical bars of metal, each of 1 inch diameter, are exposed to torsion by weights applied at the end of a 12-inch lever. What would be the probable ultimate strength in the case of good specimens of wrought iron and cast iron. State the law according to which the strength of shafting increases by increasing its diameter.

4. If a wrought-iron shaft of 1 inch diameter is broken by the torsion of a load of 800 lbs. acting at the end of a 12-inch lever, find the weight which, when applied to the end of the same lever, would break a shaft of the same material, but 3 inches in diameter. State, in general terms, the reasoning by which you arrive at the result. (S. and A. Exam., 1891.) *Ans.* 21,600 lbs.

5. If a shaft of 3 inches diameter transmits safely 33 horse-power at 100 revolutions er minute, what size of shaft will transmit safely 20 horse-power at 150 revolutions per minute. *Ans.* 2·22 inches.

6. If 800 lbs. at the end of a 12-inch lever be a safe stress to apply to a wrought-iron bar 1 square inch in section, find the effort which a shaft 2 inches in diameter can transmit at the circumference of a pulley one foot in diameter, and making 300 revolutions per minute. Find also the horse-power transmitted. *Ans.* 8,893 lbs.; 254 H.P.

7. A shaft is of given material and given diameter, find an expression for the moment of resistance to torsion. Given the maximum stress to which the material may be subjected, find the diameter of a shaft which will transmit a given horse-power at a given number of revolutions per minute.

8. A twisting moment of 9,600 inch-pounds is sufficient to break a wrought-iron shaft of 1 inch diameter. Use 6 as a factor of safety, and hence determine what horse-power can be safely transmitted through a shaft of 3 inches diameter when running at 120 revolutions per minute. Prove the formula which you employ. (S. & A. Hons. Exam., 1889.)

9. Investigate an expression for the moment of resistance to torsion of a given cylindrical shaft when subjected to a given twisting moment. What is the maximum horse-power which could be transmitted by a shaft 3 inches in diameter when making 150 revolutions per minute, it being given that the shearing stress in the material is not to exceed 7,500 lbs. per square inch? (S. & A. Hons. Exam., 1887.) *Ans.* 94·5 H.P.

10. If θ be the angle of twist expressed in circular measure in a length of shafting l, M the twisting moment, C the modulus of transverse elasticity, and d the diameter of the shaft, prove that—

$$\theta = \frac{10{\cdot}2\,\mathrm{M}\,l}{\mathrm{C}\,d^4}.$$ (S. & A. Hons. Exam., 1893.)

11. A horizontal bar of round iron, 1 inch diameter, 6 feet long, hinged at the ends, is subjected to equal and opposite pushing forces of 1,000 lbs. at its ends, and a load of 10 lbs. is hung at the middle so that it is both a beam and a strut. Find the greatest stress anywhere. $E = 29 \times 10^6$ lbs. per square inch. (Hons. S. & A. Exam., 1897.)

LECTURE XXXI.

CONTENTS.—Strength of Beams and Girders—Definitions of Shearing Force and Bending Moment—Beam Fixed at one end and Loaded at the other —Beam Fixed at one end and Loaded Uniformly—Beam Supported at both ends and Loaded in the middle—Example I.—Beam Supported at ends and Loaded anywhere — Beam Supported at both ends and Loaded Uniformly—Examples II. and III.—Floating Beams—Travelling Loads—Two Loads Moving at a Fixed Distance apart—Example IV.—Distributed Travelling Load—Questions.

Strength of Beams and Girders.—The subject under this heading is one that naturally divides itself into two portions. (1) The determination of the resultant effects of the applied loads at any section of a beam or girder; and (2) the nature and amount of the resistance offered by the beam or girder to rupture at that section.

When the section under consideration is in the same plane as the load, the only effect the load has at that section is a tendency to *shear* the beam; but in the more general case, where the load acts at a distance from the given section, we have, in addition, a tendency to curve or bend the beam at the section. Hence the name *Bending Moment* is given to this latter effect.

In the accompanying figure, let A B represent a cantilever

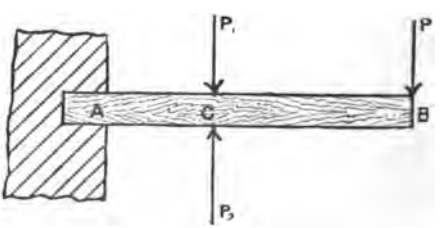

ILLUSTRATING SHEARING AND BENDING ACTION.

or beam fixed at one end, with a load P applied at the free end; and let C be any section in the beam. At C let there be applied two equal and opposite forces P_1, P_2, of the same magnitude as P. The introduction of these forces does not affect the equilibrium of the system, as P_1 and P_2 balance each other. Hence, the effect of P at the section C is equivalent to that of a

couple $P P_2$, with a single force P_1. A general proof of this important theorem is given in Vol. I., Lecture III., Prop. II. The couple constitutes the **Bending Moment** (B.M.), and the single force P_1, the **Shearing Force** (S.F.) at the section C.

DEFINITION.—**The Shearing Force at any section of a beam is the algebraic sum of all the forces acting on either side of that section.**

DEFINITION.—**The Bending Moment at any section is the algebraic sum of the moments of all the forces acting on either side of that section.**

Or, in symbols, if P denote any one of the forces acting on one side of a section, and at a distance x, from it; consider all the forces on the same side of the section as P, paying due regard to their sign—that is, if we reckon forces acting upwards as positive, we must regard those acting downwards as negative.

$$\left.\begin{array}{ll}\text{Then,} & \text{S.F.} = \Sigma P. \\ \text{And,} & \text{B.M.} = \Sigma P x.\end{array}\right\} \quad \ldots\ldots\ldots \quad \text{(I)}$$

Beam Fixed at one end and Loaded at the other.—Let C D be a cross-section anywhere within the length of the beam at a distance of x inches from the fixed end A. To find the S.F. and B.M. at C D, we observe that the only force acting to the right of the section is W lbs. Hence:—

$$\text{S.F.} = \text{W lbs.} \quad \ldots\ldots\ldots \quad \text{(II)}$$

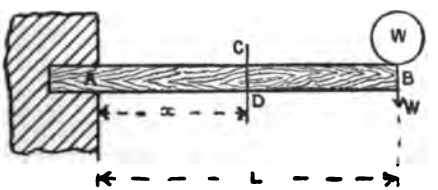

BEAM FIXED AT ONE END, LOADED AT OTHER.

It is independent of x, and therefore the same for all such sections as C D.

The B.M. at C D is W multiplied by its distance from the section in inches. Hence:—

$$\text{B.M.} = \text{W} \times \text{B D} = \text{W}(\text{L} - x) \text{ inch-lbs.} \quad \ldots \quad \text{(III)}$$

This equation is true whatever may be the position of W on the beam, so long as L denotes its distance in inches from the fixed end, and C D is between W and the support.

In this case, the diagram of the S.F. is a straight line parallel to the base and at a distance of W lbs. from it. Since (III) is the equation of a straight line, the B.M. is therefore a quantity increasing uniformly from zero, where $x = L$, to W L inch-lbs., where $x = 0$, as shown by the accompanying figure.

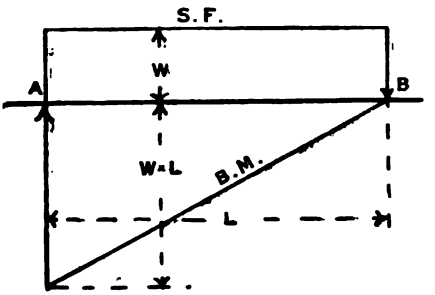

S.F. curve is a straight line.

B.M. curve is a straight line.

DIAGRAM OF S.F. AND B.M. FOR BEAM FIXED AT ONE END AND LOADED AT THE OTHER.

Beam Fixed at one end, and Loaded Uniformly.—Let the load on the beam be w lbs. per inch-run, it is required to find the shearing force and bending moment at any section C D, at x inches from the fixed end. As before, consider the part of the beam to the right of C D. The only force is the weight of that portion of the load carried by B D, so that :—

$$\text{S.F.} = w \times \text{B D} = w\,(\text{L} - x) \text{ lbs.} \quad . \quad . \quad . \quad \text{(IV)}$$

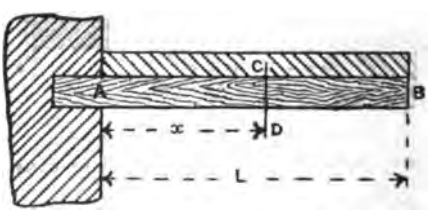

BEAM FIXED AT ONE END AND LOADED UNIFORMLY.

The moment of the portion of the load on B D with respect to C D is the same as if it were all concentrated at the middle point of B D. Hence :—

$$\text{B.M.} = w \times \text{B D} \times \tfrac{1}{2}\,\text{B D} = \tfrac{1}{2}\,w \times \text{B D}^2 = \tfrac{1}{2}\,w\,(\text{L} - x)^2 \text{ inch-lbs.} \quad \text{(V)}$$

Equations (IV) and (V) show us that both the S.F. and B.M. vanish when $x = L$; and when $x = 0$, we get :—

$$\text{S.F.} = w\,\text{L lbs.} \quad . \quad . \quad . \quad . \quad . \quad . \quad . \quad . \quad (\text{IV}_a)$$

And,

$$\text{B.M.} = \tfrac{1}{2}\,w\,\text{L}^2 \text{ inch-lbs.} \quad . \quad . \quad . \quad . \quad . \quad . \quad (\text{V}_a)$$

The diagrams of S.F. and B.M. for this case take the forms shown in the accompanying figure.

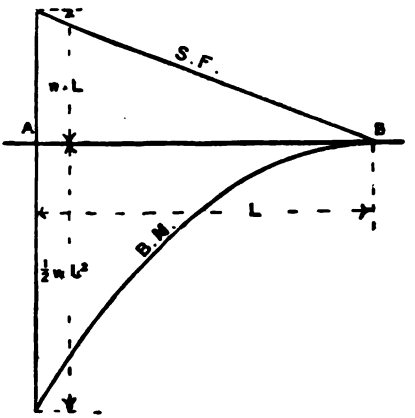

S.F. curve is a straight line.

B.M. curve is a parabola with vertex at B.

DIAGRAM OF S.F. AND B.M. FOR BEAM FIXED AT ONE END AND LOADED UNIFORMLY.

Beam Supported at both ends, and Loaded at the Middle.—In this case we measure x from the middle point of the beam. Since W is equidistant from A and B, the reactions at those points, R_1 and R_2, are equal to each other, and since their sum is W, we have :—

$$R_1 = R_2 = \tfrac{1}{2}\,\text{W lbs.}$$

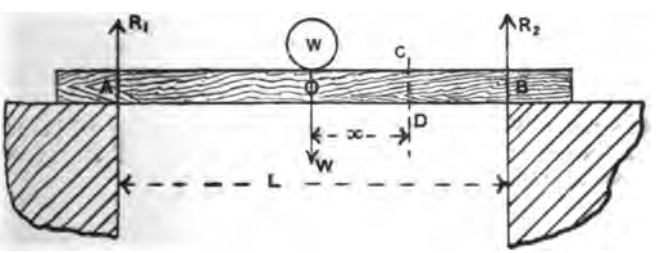

BEAM SUPPORTED AT BOTH ENDS AND LOADED AT MIDDLE.

The only force to the right of C D is R_2, and its leverage is B D.

Hence, $\quad$ S.F. $= R_2 = \frac{1}{2}$ W lbs. . . . . (VI)

And, $\quad$ B.M. $= R_2 \times BD = \frac{1}{2}W(\frac{1}{2}L - x)$ inch-lbs. . (VII)

Here, the B.M. vanishes when $x = \frac{1}{2}$ L, and increases uniformly from this until $x = 0$, when it attains its maximum value, $\frac{1}{4}$ W L inch-lbs.

Or, $\quad$ Maximum B.M. $= \frac{1}{4}$ W L inch-lbs. . . . (VII_a)

The following figure shows the diagrams of S.F. and B.M. for this case :—

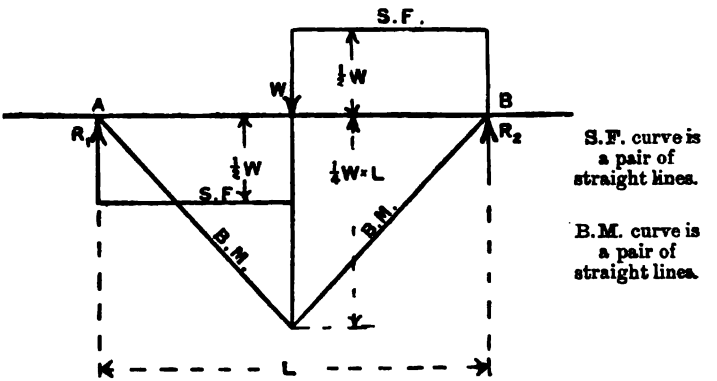

DIAGRAM OF S.F. AND B.M. FOR BEAM SUPPORTED AT BOTH ENDS AND LOADED IN MIDDLE.

EXAMPLE I.—In a beam of length L, supported at both ends and loaded at the middle with a load W, show that the bending moment is greatest at the centre of the beam and equal to $\frac{1}{4}$ W L. Then determine graphically the bending moment and shearing force at a point 6 ft. from one support in a beam of 25 ft. span loaded with 5 tons at its centre. (Adv. S. & A. Exam., 1890.)

ANSWER.—We have already seen from equation (VII) that for a beam loaded as in this example, the B.M. at any distance x, from its middle point, is :—

$$\text{B.M.} = \tfrac{1}{2}W(\tfrac{1}{2}L - x).$$

This is obviously greatest when $x = 0$—that is, at the centre. Then :—

$$\text{Maximum B.M.} = \tfrac{1}{4}WL; \text{ and S.F.} = \tfrac{1}{2}W.$$

For the values of W and L given in the example, we get :—

$$\text{Maximum B.M.} = \tfrac{1}{4} \times 5 \times 25 = 31{\cdot}5 \text{ ft.-tons.}$$

And,

$$\text{S.F.} = \tfrac{1}{2} \times 5 = 2{\cdot}5 \text{ tons.}$$

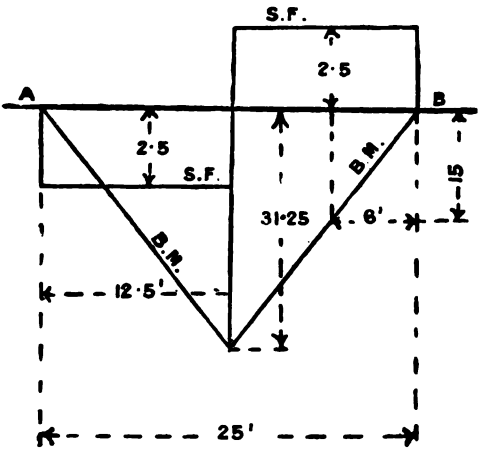

S.F. AND B.M. CURVES FOR EXAMPLE I.

The accompanying figure shows the diagrams of B.M. and S.F. as constructed from these data.

At 6 feet from one end the B.M. measures 15 ft.-tons. This is easily verified by means of the formula for B.M., because $x = 12{\cdot}5 - 6 = 6{\cdot}5$.

$$\therefore \qquad \text{B.M.} = \tfrac{1}{2} \times 5 \times (12{\cdot}5 - 6{\cdot}5) = 15 \text{ ft.-tons.}$$

Beam Supported at both ends, and Loaded Anywhere.—With a single concentrated load, the maximum bending moment will

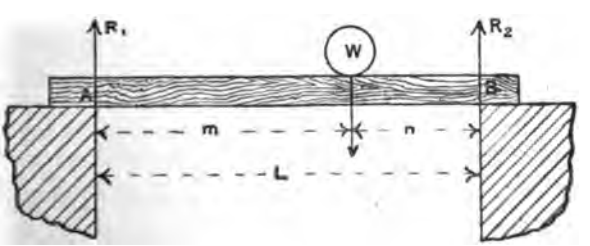

BEAM SUPPORTED AT BOTH ENDS, AND LOADED ANYWHERE.

always occur immediately under the load, whether it be at the middle of the beam or not.

For the B.M. at any section at a distance x, from one end is $R \times x$, and this is greatest when x is largest; that is, when the section is under the load.

To find the reactions at the supports, we take moments about A and B, and get $R_2 \times L = W \times m$.

$\therefore R_2 = \frac{m}{L} W$ lbs. and $R_1 = \frac{n}{L} W$ lbs. These are the values of the S.F. to the right and left of W respectively.

$$\left.\begin{aligned} \text{S.F. (to right)} &= \frac{m}{L} W \text{ lbs.} \\ \text{S.F. (to left)} &= \frac{n}{L} W \text{ lbs.} \end{aligned}\right\} \quad . \quad . \quad . \quad \text{(VIII)}$$

Multiplying the first of these equations by n, or the latter by m, we get :—

$$\text{Maximum B.M.} = \left(\frac{m\,n}{L} W\right) \text{ inch-lbs.} \quad . \quad . \quad . \quad \text{(IX)}$$

We can now construct the diagrams of S.F. and B.M. :—

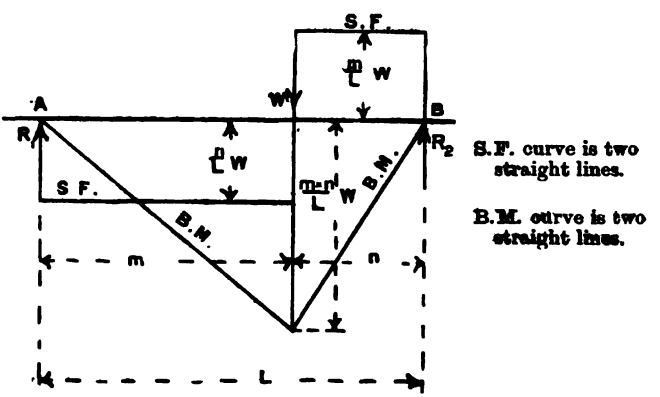

DIAGRAM OF S.F. AND B.M. FOR SINGLE LOAD IN ANY POSITION.

Beam Supported at both ends and Loaded Uniformly.—As before, let the weight per inch-run be denoted by w, then the total load carried by the beam will be w L lbs., and the reactions

R_1 and R_2, will each be $\frac{1}{2} w L$ lbs. Taking the forces to the right of the section C D.

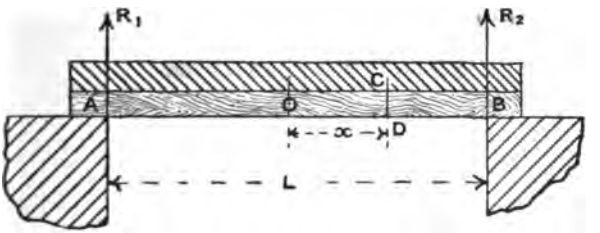

BEAM SUPPORTED AT BOTH ENDS AND LOADED UNIFORMLY.

We get, S.F. $= R_2 - w \times BD = \frac{1}{2} w L - w(\frac{1}{2}L - x) = w\,x$ lbs. (X)

And, B.M. $= R_2 \times BD - w \,.\, BD \times \frac{1}{2} BD$

$$\text{,,} \quad = \tfrac{1}{2} w L \times BD - \tfrac{1}{2} w \,.\, BD^2$$

$$\text{,,} \quad = \tfrac{1}{2} w \,.\, BD(L - BD)$$

$$\text{,,} \quad = \tfrac{1}{2} w (\tfrac{1}{2} L - x)(\tfrac{1}{2} L + x).$$

$$\therefore \quad B.M. = \tfrac{1}{2} w (\tfrac{1}{4} L^2 - x^2) \text{ inch-lbs.} \quad . \quad . \quad . \quad . \quad . \quad (XI)$$

The limiting values of S.F. and B.M. are :—

When, $x = \frac{1}{2} L$; then, S.F. $= \frac{1}{2} w L$ lbs.; and, B.M. $= 0$. (X_a)

When, $x = 0$; then, S.F. $= 0$; and :—

$$\text{Maximum, B.M.} = \tfrac{1}{8} w L^2 \text{ inch-lbs.} \quad . \quad . \quad (XI_a)$$

Plotting our diagrams of S.F. and B.M., we get the figure shown on next page.

When a beam carries more than one load, or is loaded in more ways than one, the simplest and safest way is to consider each load separately, without regard to the others, and then combine the separate effects so as to obtain the resultant action, as in Example II.

EXAMPLE II.—Draw the bending moment and shearing force diagrams for a beam 12 feet long, supported at both ends, and loaded with weights of 4 and 6 tons at distances of 3 and 8 feet respectively, from one end of the beam. Explain fully the mode of arriving at these diagrams. (Adv. S. & A. Exam., 1887.)

ANSWER.—Measuring distances from the left end of the beam, and considering each load separately, we have, for the 4 tons, to the left of the load :—

$$S.F._1 = \frac{n}{L} W = \frac{9}{12} \times 4 = 3 \text{ tons.}$$

And, to the right of it :—

$$S.F._1 = \frac{m}{L} W = \frac{3}{12} \times 4 = 1 \text{ ton.}$$

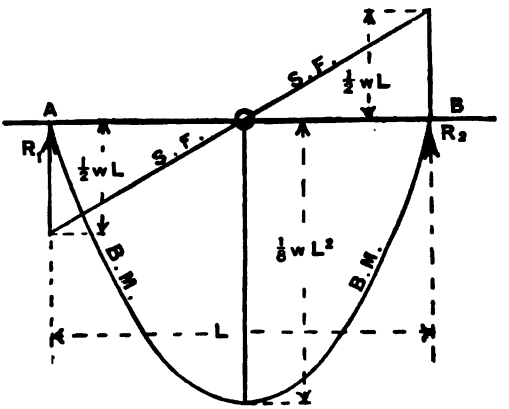

S.F. curve is a straight line.

B.M. curve is a parabola with vertex below the middle of the beam.

DIAGRAM OF S.F. AND B.M. FOR A BEAM SUPPORTED AT BOTH ENDS AND LOADED UNIFORMLY.

The maximum $B.M._1$ due to this load is :—

$$B.M._1 = \frac{m \times n}{L} W = \frac{3 \times 9}{12} \times 4 = 9 \text{ ft.-tons.}$$

It occurs immediately under the load.

Next taking the 6-tons load, we have to the left of it :—

$$S.F._2 = \frac{n}{L} W = \frac{4}{12} \times 6 = 2 \text{ tons ;}$$

And to the right of it :—

$$S.F._2 = \frac{m}{L} W = \frac{8}{12} \times 6 = 4 \text{ tons.}$$

The maximum $B.M._2$ due to the 6 tons is :—

$$B.M._2 = \frac{m \times n}{L} W = \frac{8 \times 4}{12} \times 6 = 16 \text{ ft.-tons.}$$

Plotting these results, we get the accompanying figure :—

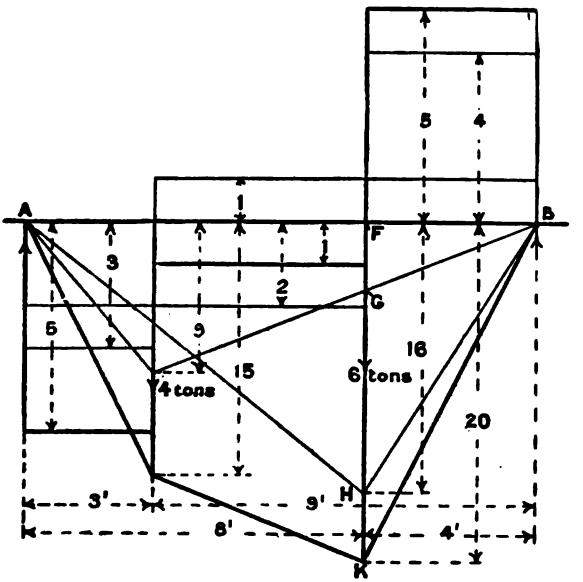

S.F. AND B.M. CURVES FOR EXAMPLE II.

The thin lines show the actions of the separate loads, and the full lines their combined results, obtained by taking the algebraic sum of the former.

The student should here carefully observe the necessity of attending to the *sign* of the shearing force. Thus, between the weights we have a shearing force of 2 tons, which, on account of its sign, is drawn below the base line; also a shearing force of 1 ton drawn above the base line. The resultant shearing force between the loads is therefore the difference of these, and is drawn on the same side of the base line as the greater of its components.

The bending moments everywhere along the beam are of the same sign; therefore, to obtain the combined bending moment diagram, we have simply to add the ordinates of each separate diagram. Thus, to get the total bending moment at the section under the 6 tons load, we add F G (viz., that due to the 4 tons at that point) to F H (that due to the 6 tons). The result F K is therefore the total B.M. at that point.

It is quite sufficient to do this for the sections under each load, and then to join each of the points so obtained with each other and with the ends of the beam by straight lines. If drawn to scale, the B.M. at any other point can then be obtained by measuring the corresponding ordinate.

EXAMPLE III.—A horizontal uniform bar, 18 inches long, is laid over two supports, each 4 inches from its ends. Find two points at which the bending moments are zero. (Hons. S. & A. Exam.)

ANSWER.—Let w be the weight in lbs. per inch-run of the bar. Then the total weight of the bar will be $18w$ lbs., and the reactions will each be $9w$ lbs.

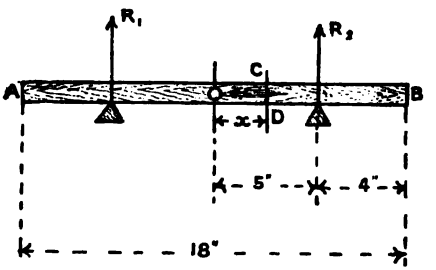

ILLUSTRATING EXAMPLE III.

Taking moments to the right of the section C D at a distance x inches from the centre of the bar, we get:—

$$\begin{aligned} \text{B.M.} &= R_2(5 - x) - w \,.\, BD \times \tfrac{1}{2} BD \\ \text{,,} &= 9w(5 - x) - \tfrac{1}{2} w \,.\, BD^2 \\ \text{,,} &= 9w(5 - x) - \tfrac{1}{2} w (9 - x)^2 \\ \text{,,} &= \tfrac{1}{2} w (9 - x^2) \text{ inch-lbs.} \end{aligned}$$

The B.M. will be zero when $9 - x^2 = 0$; *i.e.*, when $x = \pm 3$ inches.

Hence, the required points are 3 inches on each side of the centre, or 2 inches inside of the supports.

Floating Beams.—When a *solid* body, such as a piece of wood of *uniform density*, floats in *still* water its weight and its buoyancy, or the resultant upward pressure of the water on the body, will at all points balance each other. There are consequently no shearing or bending stresses on the body, and each part is in equilibrium independently of the other parts.

But whenever those conditions are departed from, such as (1) when the floating body carries weights; (2) when it is not of uniform density, due to want of homogeneity in its material, if solid, or to its being hollow, or of a boat form; or (3) when it crosses waves, then bending and shearing stresses are set up.

Consider the case of a uniform beam of wood of rectangular section floating in still water. The beam will displace an amount of water exactly equal to its own weight. This is true, not only for the beam as a whole, but also for every individual segment of the beam. Any segment of the beam will displace just as much, and no more, water than it would do if floating by itself. The beam, therefore, is as free from stress as it would be if it were lying on a perfectly flat surface.

Suppose now that a weight W, be placed on the middle of a floating beam. This will cause the beam to sink to a greater depth and displace an *extra* volume of water. The *weight* of this *extra* displacement is exactly equal to W. What, now, is the condition of the beam as regards straining forces? Evidently, we need only consider the weight W, and the extra displacement, due to its being carried by the beam; because the upward reaction of the displacement due to the beam's own weight, is still at all points balanced by the downward weight of the beam. In other words, the condition of the beam, so far as its own weight and displacement are concerned, is in no way affected by the addition of the load.

To give definiteness to our ideas, let W be expressed in lbs., and let L denote the length of the beam in inches.

Then the forces we have to consider are:—

(1) W lbs. concentrated at the middle of the beam and acting downwards.

(2) The displacement of W lbs. of water uniformly distributed along the whole length of the beam and acting upwards, with an intensity of $\frac{W}{L}$ lbs. per inch of length.

The case is, therefore, analogous to that of a beam uniformly loaded and supported at its centre; or what is virtually the same thing, two beams of length equal to $\frac{1}{2}$ L, fixed at one end and loaded uniformly. For, in order to obtain the shearing force and the bending moment at any section of the beam, x inches to either side of W, we have simply to substitute $\frac{W}{L}$ for w, and $\frac{1}{2}$ L for L in equations (IV) and (V), and we get:—

$$S.F. = \frac{W}{L}(\tfrac{1}{2}L - x) \text{ lbs.} \quad . \quad . \quad . \quad . \quad . \quad \text{(XII)}$$

And, $$\text{B.M.} = \frac{W}{2L}\left(\tfrac{1}{2}L - x\right)^2 \text{ inch-lbs.} \quad . \quad . \quad \text{(XIII)}$$

Under W the shearing force and bending moment are each a maximum. Their values may be found by making $x = 0$.

Then the $$\text{Maximum S.F.} = \tfrac{1}{2}W \text{ lbs.} \quad . \quad . \quad . \quad (\text{XII}_a)$$

And the $$\text{Maximum B.M.} = \tfrac{1}{8}WL \text{ inch-lbs.} \quad . \quad (\text{XIII}_a)$$

The diagrams of S.F. and B.M. for this case are constructed in identically the same way as for a beam fixed at one end and carrying a uniform load, but taking $\frac{1}{2}$ L as a base line instead of L.

Suppose that, instead of one weight in the middle, the beam is loaded with two weights, one at each end, and each equal to W lbs., it is easy to see that the condition now is that of a beam uniformly loaded with $\frac{2W}{L}$ lbs. per inch-run and supported at each end. We have, therefore, only to apply formulæ (X) and (XI), substituting $\frac{2W}{L}$ for w, when we get:—

$$\text{S.F.} = \frac{2W}{L} \cdot x \text{ lbs.} \quad . \quad . \quad . \quad . \quad . \quad . \quad . \quad . \quad . \quad \text{(XIV)}$$

And, $$\text{B.M.} = \frac{W}{L}\left(\tfrac{1}{2}L^2 - x^2\right) \text{ inch-lbs.} \quad . \quad . \quad . \quad . \quad \text{(XV)}$$

Here the shearing force is a maximum when $x = \frac{1}{2}$ L, and the bending moment a maximum when $x = 0$.

Or, $$\text{Maximum S.F.} = W \text{ lbs.} \quad . \quad . \quad . \quad . \quad . \quad . \quad (\text{XIV}_a)$$

And, $$\text{Maximum B.M.} = \tfrac{1}{4}WL \text{ inch-lbs.} \quad . \quad . \quad (\text{XV}_a)$$

The diagrams of S.F. and B.M. are, therefore, in every way similar to those for a uniformly loaded beam supported at the ends.

Travelling Loads.—The simplest case of a movable load is that, wherein we are given a weight, say a heavy cylindrical body, rolling along a beam, to find the equations of maximum S.F. and B.M. for any position of the load, and exhibit these results in a diagram.

Referring to formulæ (VIII) and (IX), and the diagrams already deduced for a fixed load in *any* position on a beam, we

have for the maximum S.F. to the immediate right of the load :—

$$\text{S.F.} = \frac{m}{L} \text{ W lbs.}$$

And, to the immediate left of the load :—

$$\text{S.F.} = -\frac{n}{L} \text{ W lbs.}$$

For the maximum B.M., which occurs immediately under the load :—

$$\text{B.M.} = \frac{m\,n}{L} \text{ W inch-lbs.}$$

Putting $m = x$ so that $n = L - x$, we obtain, when the load is x inches from the left end of the beam :—

$$\left.\begin{array}{ll} \textbf{The Maximum S.F.} \textit{ (just to right of the section)} = \frac{W}{L}x \\ \quad\text{,,} \qquad \text{,,} \qquad \textit{(just to left of the section)} = \frac{W}{L}(x-L) \end{array}\right\} \text{(XVI)}$$

$$\textbf{And,} \qquad \textbf{Maximum B.M.} = \frac{W}{L}(L - x)x. \quad . \quad . \quad . \quad . \quad \text{(XVII)}$$

To construct the diagram of S.F., we observe that its equation is that of a straight line, and that to the right of the section considered its value is zero when the load just starts from the left end of the beam, and increases uniformly as the load approaches the other end. That is :—

When, $x = 0$; then, S.F. $= 0$.

Also when, $x = L$; then, S.F. $= W$ lbs.

There is also another line for the shear at all positions just to the left of the load. This line passes through B, and its ordinate is $-W$ at the end A.

The equation of the B.M. curve is that of a parabola, whose axis is vertical, and passes through the middle point of the beam, where, of course, the maximum value of B.M. occurs. To construct this diagram, we have :—

When, $x = 0$, or $x = L$; then B.M. $= 0$.

Also when, $x = \frac{1}{2}L$; then B.M. $= \frac{1}{4}$ W L inch-lbs.

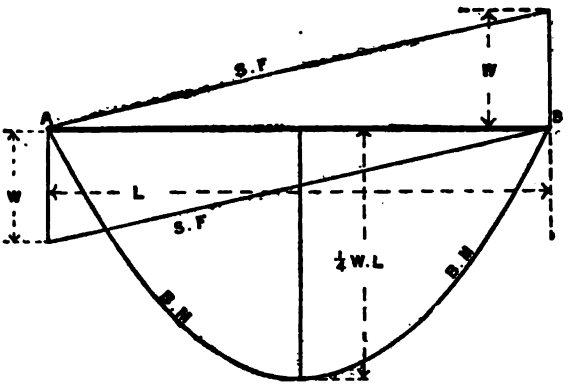

DIAGRAMS OF MAXIMUM S.F. AND B.M. FOR ROLLING LOAD.

Two Loads moving at a fixed distance apart.—From the above simple case we may easily pass to a very important practical example of moving loads—viz., overhead travelling cranes.

Here the crane rests on a carriage with four wheels running on two rails carried by girders, the weight of the whole machine together with the load being equally distributed over the wheels. Hence, considering one girder only, our problem is reduced to that of two equal loads moving along the girder at a fixed distance apart.

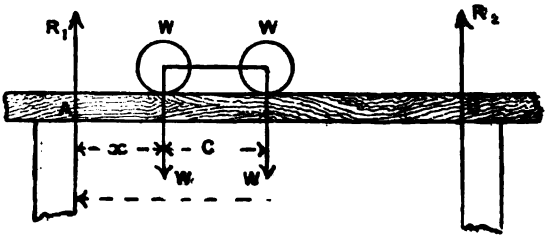

ILLUSTRATING TRAVELLING CRANE PROBLEM.

In the figure let W be the weight resting on each wheel, and c be the distance between their centres. If the motion be supposed to be in the direction shown by the arrow, it is evident that until the carriage gets to the middle of the girder the maximum

shearing force and bending moment will occur under the leading wheel—that is, if we estimate the shearing force to the immediate right of the wheel. But as the same thing takes place in the reverse order when the carriage moves from the other end of the girder in the opposite direction, we shall take the section of the girder immediately under the following wheel and estimate the shearing force and bending moment for that position. This method of procedure will be found to lead to simpler equations than if we had taken the leading wheel as our point of reference.

Now, considering the forces acting to the left of the wheel, we easily see :—

That, $\quad$ S.F. $= R_1$.

And, $\quad$ B.M. $= R_1 \times x$.

To find R_1 we take moments about B, which gives us :—

$$R_1 \times L = W\{L-(x+c)\} + W(L-x)$$

$$\text{,,} \quad \text{,,} = W\{2(L-x)-c\}.$$

$$\therefore \qquad R_1 = \frac{W}{L}\{2(L-x)-c\}.$$

Hence, $$\text{S.F.} = \frac{W}{L}\{2(L-x)-c\}. \quad . \quad . \quad . \quad \text{(XVIII)}$$

And, $$\text{B.M.} = \frac{W}{L}\{2(L-x)-c\}x. \quad . \quad . \quad . \quad \text{(XIX)}$$

The equation for the S.F. is that of a straight line, and for the B.M. a parabola. To find the position and dimensions of those diagrams, we see that :—

When $\quad x = 0$, S.F. $= \frac{W}{L}(2L - c)$, and B.M. $= 0$.

Again, both S.F. and B.M. will vanish when $2(L-x) - c = 0$; that is, when $x = L - \frac{c}{2}$.

To find the maximum ordinate of the B.M. curve, we have the condition that, when the B.M. is a maximum :—

$$\frac{d}{dx}(\text{B.M.}) = 0.$$

That is, $$\frac{d}{dx}\{2(L-x)-c\}x = 0.$$

Or, $$\frac{d}{dx}\{(2L-c)x - 2x^2\} = 0.$$

$$(2L - c) - 4x = 0.$$

Hence, $$x = \frac{L}{2} - \frac{c}{4}.$$

The shearing force diagram will, therefore, consist of two straight lines parallel to each other, and the bending moment diagram will consist of two equal parabolas intersecting at the middle of the girder. The axes of these equal parabolas will be equidistant from the middle of the girder and $\frac{1}{2}c$ units apart.

The following numerical example will elucidate this important case much better than a bare examination of formulæ:—

EXAMPLE IV.—In a travelling crane of 40 feet span the load is supported on a carriage which runs upon two similar girders, the axles of the carriage being 8 feet apart, and a load of $2\frac{1}{2}$ tons coming upon each wheel. Obtain a diagram showing the maximum bending moment at every section of the girder, and give the numerical values at distances of 10, 15, and 20 feet from one end. (Hons. S. & A. Exam., 1880.)

ANSWER.—Applying our general formulæ, we have, for the bending moment at any distance x ft, from one end:—

$$\text{B.M.} = \frac{W}{L}\left[(2L-c) - 2x\right]x.$$

Here, $W = 2{\cdot}5$ tons, $L = 40$ ft., and $c = 8$ ft.

$$\therefore \quad \text{B.M.} = \frac{2{\cdot}5}{40}\left[80 - 8 - 2x\right]x.$$

Or, $$\text{B.M.} = \tfrac{1}{8}(36 - x)\,x \text{ ft.-tons.}$$

For the numerical values asked for, we have:—

When $x = 10$ ft.; B.M. $= \frac{1}{8}(36 - 10)\,10 =$ **32·5 ft.-tons.**

When $x = 15$ ft.; B.M. $= \frac{1}{8}(36 - 15)\,15 =$ **39·375 ft.-tons.**

When $x = 20$ ft.; B.M. $= \frac{1}{8}(36 - 20)\,20 =$ **40 ft.-tons.**

We have seen, that the B.M. attains its maximum value when:—

$$x = \frac{L}{2} - \frac{c}{4} = \frac{40}{2} - \frac{8}{4} = 18 \text{ ft.}$$

Hence, the maximum B.M. $= \frac{1}{8}(36 - 18)\,18 =$ **40·5 ft.-tons.**

The S.F. is not asked for in the question, but we here add it so as to make the example more complete.

The maximum S.F. occurs when $x = 0$, and when $x = L$, its value for this case then being :—

$$\text{Maximum S.F.} = \frac{2 \cdot 5}{40}(80 - 8) = 4 \cdot 5 \text{ tons.}$$

And, like the B.M., it is zero when $x = 40 - \frac{8}{2} = 36$ feet.

The following figure shows the S.F. and B.M. diagrams as required for this example.

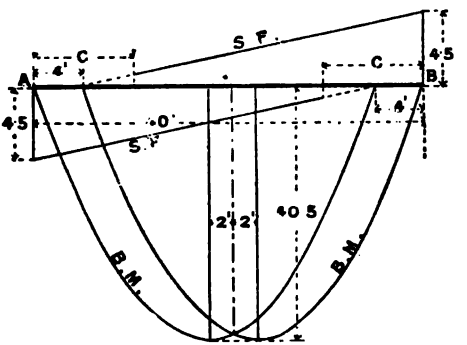

DIAGRAM OF MAXIMUM S.F. AND B.M. FOR A TRAVELLING CRANE.

Distributed Travelling Load.—The last case we shall consider is that in which a continuous load of uniform density, and long enough to completely cover it, comes on to a girder and moves off at the other end, such as a long train of uniform weight passing over a bridge.

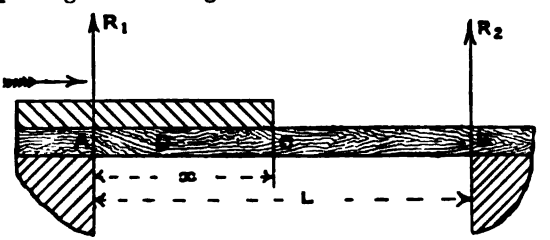

ILLUSTRATING TRAVELLING LOAD OF UNIFORM INTENSITY.

In the figure, let w denote the load per unit of length. When the load is in the position shown, it is clear that the S.F., at all points to the right of C, will be equal to R_2; and that at any section D, to the left of C, the S.F. will be less than R_2 by the weight of the portion of the load covering C D. It at once

follows that the S.F. is greatest at C, the front of the load, and this is true for all positions of C.

Hence, $$\text{S.F.} = R_2.$$

Taking moments about A, we have :—

$$R_2 \times L = w x \times \tfrac{1}{2} x.$$

$$\therefore \qquad R_2 = \frac{w x^2}{2 L}.$$

That is, $$\text{S.F.} = \frac{w x^2}{2 L} \quad . \quad . \quad . \quad . \quad . \quad . \quad . \quad . \quad . \quad \text{(XX)}$$

The shearing force is, therefore, proportional to the square of the length of the part of the load resting on the girder.

The curve of the maximum bending moment is very easily deduced in this case. We have only to remember that the B.M. at *any fixed* section in the girder will get greater and greater for every additional part of the load that comes upon it; so that when the girder is wholly covered by the load the B.M. at every position will then be a maximum. The B.M. diagram is therefore identical with that given for a beam loaded uniformly, whilst the S.F. diagram becomes a parabola instead of a straight line.

The following figure shows how the S.F. and B.M. diagrams are constructed for this case.

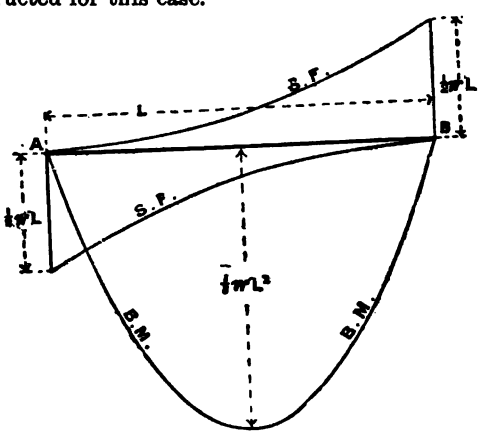

S.F. AND B.M. DIAGRAMS FOR TRAVELLING CONTINUOUS LOAD OF UNIFORM INTENSITY.

LECTURE XXXI.—QUESTIONS.

1. Define "*bending moment*" and "*shearing force.*" A uniform beam weighing 15 cwts. rests on supports at its ends 20 feet apart. The beam is loaded with three weights of 4, 6, and 10 cwts. at distances of 2, 7, and 12 feet respectively from one of the supports. Find the B.M. and S.F. at a point 8 feet from the same support. *Ans.* B.M. = 98 ft.-cwts.; S.F. = 3 cwts.

2. A bar of pine 44 inches long rests on props at its extremities, and just supports 10 weights, of 14 lbs. each, hung at equal intervals of 4 inches along the rod. Find the amount of a single weight, which, if hung at the centre of the bar, would strain it to the same extent. *Ans.* 43·27 lbs.

3. A batten of fir, 6 feet in length and supported at its extremities, will just sustain a load of 520 lbs. when hung at the centre. If this weight be removed, and two weights, each equal to P lbs., be hung at distances of 2 and 4 feet along the bar, what is the greatest value which may be assigned to P? *Ans.* 390 lbs.

4. A beam, 20 feet long, whose weight is neglected, is supported at both ends and loaded with 1 ton evenly distributed along its length. Find the bending moment at a distance of 7 feet from one end. *Ans.* 5,096 ft.-lbs.

5. A beam, whose weight may be neglected, rests on supports at its ends 15 feet apart. Weights of 10, 6, 5, and 12 cwts. rest on the beam at intervals of 3 feet apart, the weight of 10 cwts. being 3 feet from one support. Find the points where the maximum bending moment and shearing force occur, and obtain their values. Construct the diagrams of bending moments and shearing force for the whole beam. *Ans.* The *max.* B.M. = 66 ft.-cwts., and occurs at all points between the weights 6 and 5 cwts.; the *max.* S.F. = 17 cwts., and occurs at the point where the weight of 12 cwts. rests.

6. A uniform cantilever, or beam fixed at one end and free at the other, 10 feet long, weighs 6 cwts., and carries two loads, one of 2 cwts. at the free end, and the other 4 cwts. at its middle point. Construct the shearing force diagram for the whole cantilever, and find the shearing forces at points $2\frac{1}{2}$ feet and 6 feet from fixed end. *Ans.* 10·5 cwts.; 6·4 cwts.

7. A block of wood weighing 800 lbs., 20 feet long and 12 inches square, floats in water, and is loaded—

(1) By a weight of 200 lbs., placed at each extremity;

(2) By a weight of 400 lbs. at the centre.

Show what forces act on the beam, and draw the curves of shearing force and bending moment for each case. (S. & A. Exam., 1892.)

8. A girder is supported at both ends, and has a clear span of 30 feet. Show by means of a curve the position and magnitude of the greatest bending moment produced by a load of 20 tons as it rolls from one end to the other of the girder. Obtain the numerical results for distances respectively of 10 and 15 feet from one end. (S. & A. Hons. Exam., 1895.)

9. Prove an algebraic formula to show that, with a continuous load of uniform intensity passing over a beam AB such as when a long train passes over a bridge A to B, the maximum shearing stress to any point K of the beam occurs when the part AK is fully loaded while the part

K B is entirely unloaded, and that the magnitude of the stress is proportional to the square of the distance of K from the point A. A train of 1 ton per foot run, and upwards of 100 feet in length, passes over a bridge of 100 feet span; what would be the maximum shearing stresses at distances of 25 and 50 feet respectively from one end of the bridge? Show how to determine graphically the shearing stresses in the beam. (S. & A. Hons. Exam., 1896.)

10. What occurs at the cross-section of a horizontal beam, carrying vertical loads? Where is the neutral line? What is the value of the stress at any place? What is meant by *bending moment?* Describe any model which illustrates, however roughly, what occurs at a section of the beam. (Adv. S. & A. Exam., 1898.)

LECTURE XXXII.

CONTENTS.—Resistance of Beams to Flexure—Examples I., II., III., and IV.—Thin Wrought-Iron Girders—Example V.—Curvature and Deflection of Beams—Example VI.—Uniform Beam on Three Supports—Uniform Beam fixed at one end and supported at the other—Beams fixed at both ends and loaded at centre—Beams fixed at both ends and loaded uniformly—Tables—Questions.

Resistance of Beams to Flexure.—In the previous Lecture we saw that the effect of loading a beam was to give rise to both shearing and bending.

From the theory of couples set forth in Vol. I. we know that nothing but a couple can balance a couple. The resistance which a beam offers to bending must be of this nature, and therefore a couple of equal magnitude to that of the applied load, but of opposite tendency. The tendency of the applied couple is to bend or curve the beam, whilst the tendency of the induced couple is to oppose this curving action.

When a beam is curved the longitudinal fibres on the convex side of it are stretched beyond their normal length, and consequently they are in tension. On the concave side the fibres

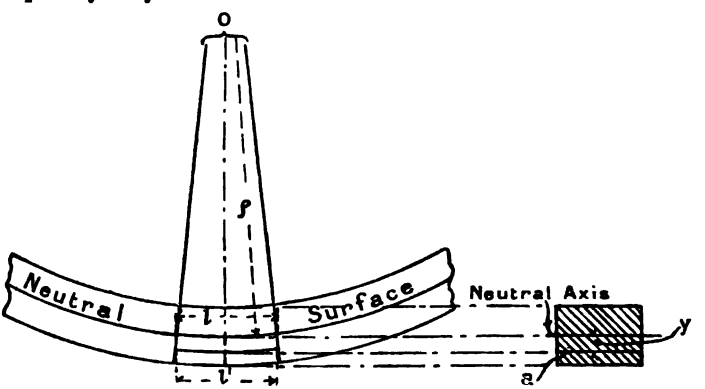

ILLUSTRATING FLEXURE OF BEAMS.

are shortened, and, therefore, they are in compression. Somewhere within the beam there must be a layer of fibres that are neither lengthened nor shortened, and are therefore unstressed.

This layer is termed the *neutral surface* of the beam, and the intersection of this surface with any cross-section of the beam is termed the *neutral axis* of that section. The neutral axis is of fundamental importance in the theory of beams, because it is the fulcrum about which both the bending and resisting couples act.

We shall now find the position of the neutral axis of any given section of a beam.

Let l be the length of a small portion of the neutral surface; l' that of a parallel layer of fibres on the stretched side of the beam, and at a distance y, from the neutral surface. If $l' = l$ when the beam is straight, it is evident that the amount of stretch in the fibres at distance, y, from the neutral surface will be $l' - l$, and the *strain* $\frac{l' - l}{l}$. Let ρ denote the radius of curvature of the neutral surface at the cross-section bisecting l. Then the radius of curvature corresponding to l' will be $= \rho + y$.

Hence, $$\frac{\rho + y}{\rho} = \frac{l'}{l},$$

Or, $$\frac{y}{\rho} = \frac{l' - l}{l}.$$

If f be the tensile stress at distance y, from the neutral axis, and E the modulus of elasticity of the material, we already know that:—

$$\frac{\text{stress}}{\text{strain}} = \text{E},$$

Or, $$\frac{f}{\frac{l' - l}{l}} = \text{E}.$$

Substituting $\frac{y}{\rho}$ for $\frac{l' - l}{l}$, and inverting, we get:—

$$\frac{1}{\rho} = \frac{f}{\text{E}y}. \quad \ldots\ldots\ldots \quad \text{(I)}$$

If we had considered in the same way a layer of fibres at a distance y', to the concave side of the neutral surface, and denoted the stress there as $-f'$ (the minus sign indicating compressive stress), we should have arrived at the equation:—

$$\frac{1}{\rho} = \frac{-f'}{\text{E}y'}. \quad \ldots\ldots\ldots \quad (\text{I}_a)$$

Let a be a small element of the cross-sectional area at a distance y, then on the one side of the neutral axis we have for the total resistance to tension :—

$$\Sigma af = \frac{E}{\rho} \Sigma ay. \quad . \quad . \quad . \quad . \quad . \quad (II)$$

On the other side of the neutral axis the total resistance to compression is :—

$$-\Sigma af' = \frac{E}{\rho} \Sigma ay'. \quad . \quad . \quad . \quad . \quad . \quad (II_a)$$

But these forces constitute a couple, and are therefore equal. Hence, equating the right hand members, we have, neglecting the common factor, $\frac{E}{\rho}$:—$\Sigma ay = \Sigma ay'$.

The neutral axis, therefore, passes through the centre of area of each cross-section. If, however, E be not the same for Tensile and Compressive stresses, then the N.A. will not pass through the centre of the area, but will lie to the side having the greater value of E.

To obtain the magnitude of the resisting couple, we multiply the resistanees, af and af', by their respective distances, y and y', from the neutral axis, and sum up these products for the whole section. Thus, from equation (II) the total moment of resistance on the convex side of the neutral axis is :—

$$\Sigma afy = \frac{E}{\rho} \Sigma ay^2;$$

And on the concave side :—

$$-\Sigma af'y' = \frac{E}{\rho} \Sigma ay'^2.$$

The sum of these results constitutes the total Resisting Moment, R.M., for the section.

Hence, $$\text{R.M.} = \frac{E}{\rho} \Sigma ay^2 + \frac{E}{\rho} \Sigma ay'^2.$$

There is now no longer any need for distinguishing between y and y', since the process of summation is the same all over the cross-section. We, therefore, finally get :—

$$\text{R.M.} = \frac{E}{\rho} \Sigma ay^2. \quad . \quad . \quad . \quad . \quad . \quad . \quad (III)$$

The quantity Σay^2, being a purely geometrical function, depending only on the *form* of the section, is termed its

Moment of Inertia, and is usually denoted by the symbol I, and sometimes by the product $A k^2$ (see Lecture XXII). Table II., Lecture XXII., gives the values of k^2 for most of the sections required in the following examples. These multiplied by A will give the required values of I.

Writing I for $\Sigma a y^2$, our equations become :—

$$\text{B.M.} = \text{R.M.} = \frac{E I}{\rho};$$

$$\text{Or,} \quad \text{the curvature,} \frac{1}{\rho} = \frac{M}{E I}. \quad \ldots \ldots \ldots \quad \text{(IV)}$$

Where M stands for either the B.M. or R.M.

Again, from equations (I) and (I_a), we get :—

$$\left.\begin{aligned} & \frac{f}{y} = \frac{E}{\rho} = \frac{M}{I} \\ \therefore \quad & M = \frac{f}{y} I \\ \text{Or,} \quad & f = \frac{M}{I} y \end{aligned}\right\} \quad \ldots \ldots \ldots \quad \text{(V)}$$

Formulæ (IV) and (V) are the fundamental equations of the theory of the strength of beams and girders. In applying the latter equation, it must always be borne in mind that f stands for either the tensile or compressive stress at any distance y, above or below the neutral axis.

The greatest stress comes on the fibres farthest from the neutral axis, and is the principal effect to be considered in questions of strength. If this is amply provided for, the beam will be safe. Let y now denote the distance of the fibres farthest from the neutral axis :—

$$\text{Then,} \quad f_{max.} = \frac{M}{I} \times y = M \div \frac{I}{y}.$$

The ratio $\frac{I}{y}$ is usually denoted by Z, and is called the **Modulus of the Section.***

*See Prof. Unwin's *Elements of Machine Design*, Pages 56 to 59, for a table of the moduli of sections of beams, where $Z = \frac{I}{y}$. Also, in Seaton & Rounthwaite's *Pocket Book of Marine Engineering Rules and Tables*, from which we extracted the tables at the end of this lecture, we also find $Z = \frac{I}{y}$ as the modulus of the section.

Hence, writing Z for $\frac{I}{y}$, we have :—

$$\left.\begin{aligned} f_{max.} &= \frac{M}{Z} \\ \text{Or,} \qquad M &= Z f_{max.} \end{aligned}\right\} \quad . \quad . \quad . \quad . \quad . \quad . \quad . \quad (VI)$$

In applying this equation the student must be careful to remember that in those cases where the section of the beam or girder is not symmetrical about the neutral axis, there will be two values of y to be taken into account, and therefore two values of Z. On the whole, we think it safer to adhere to the general formula (V) as being less likely to lead to confusion; at the same time, it is very convenient to use equation (VI) in taking out quantities in the drawing office by aid of tables since it reduces the work of calculation.

EXAMPLE I.—A floor joist, 12 inches deep and 3 inches broad, has a span of 15 feet, and carries a uniformly distributed load of 1 cwt. per foot-run. Find the greatest intensity of stress within the timber. (S. and A. Adv. Exam., 1891.)

ANSWER.—In problems involving the calculation of stress within the beam, the student will find it best to express all dimensions in *inches*, and, therefore, bending moments in *inch-lbs.* or *inch-tons* as the case may be.

In this problem the greatest stresses will occur at the middle of the joist where the bending moment attains its maximum value, which, in this case, is :—

$$\text{Max. B.M.} = \tfrac{1}{8}\, w\, L^2 \text{ inch-lbs.}$$

$$\text{Here,} \qquad w = \frac{112}{12} \text{ lbs.}$$

$$\text{And,} \qquad L = 15 \times 12 \text{ inches.}$$

$$\therefore \qquad \text{B.M.} = \frac{1}{8} \times \left(\frac{112}{12}\right) \times (15 \times 12)^2 \text{ inch-lbs.}$$

$$\text{Or,} \qquad \text{B.M.} = 14 \times 15 \times 15 \times 12 \qquad \text{,,}$$

The value of I for a rectangular section is :—

$$I = \frac{1}{12}(\text{breadth}) \times (\text{depth})^3,$$

$$\text{Or,} \qquad I = \frac{1}{12} \times 3 \times 12^3 = 3 \times 12 \times 12.$$

The greatest stress at the middle section of the joist will occur in the fibres farthest away from the neutral axis. Hence, $y = 6$ inches.

Applying equation (V) we have :—

$$f = \frac{\text{B.M.}}{\text{I}}\, y,$$

$$\text{,,} = \frac{14 \times 15 \times 15 \times 12}{3 \times 12 \times 12} \times 6 = \mathbf{525\ lbs.\ per\ sq.\ in.}$$

EXAMPLE II.—A uniform beam of oak, 10 feet long, 15 inches deep and 10 inches wide, sustains, in addition to its own weight, a load of 5,000 lbs. placed at the centre. Find the greatest bending moment and the greatest stress in the fibres.

The specific gravity of oak is 0·934. (S. and A. Adv. Exam., 1894.)

ANSWER.—Here the greatest bending moment takes place at the centre of the beam and is made up of two parts: (1) that due to the beam's own weight which is uniformly distributed along its length; and (2) that due to the 5,000 lbs. concentrated at its middle.

For (1), $\text{B.M.}_1 = \frac{1}{8}\, w\, \text{L}^2$ inch-lbs.

And for (2), $\text{B.M.}_2 = \frac{1}{4}\, \text{W L}$,,

$\therefore$ Total, $\text{B.M.} = \frac{1}{8}\, w\, \text{L}^2 + \frac{1}{4}\, \text{W L}$ inch-lbs.

Taking the weight of a cubic inch of water as 0·036 lb., then a cubic inch of oak will weigh $0{\cdot}934 \times 0{\cdot}036 = 0{\cdot}0336$ lb.

$\therefore \quad w = 0{\cdot}0336 \times 15 \times 10 = 5{\cdot}04$ lbs.

And, $\text{B.M.} = \frac{1}{8} \times 5{\cdot}04 \times (10 \times 12)^2 + \frac{1}{4} \times 5{,}000 \times (10 \times 12)$

$\text{,,} = 9{,}072 + 150{,}000 = \mathbf{159{,}072\ inch\text{-}lbs.}$

Here, $\text{I} = \frac{1}{12} \times 10 \times 15^3 = \frac{1}{2} \times 5 \times 5 \times 15 \times 15$

And, $y = \frac{1}{2} \times 15$ inches.

$$\therefore \quad f = \frac{\text{B.M.}}{\text{I}}\, y = \frac{159{,}072}{\frac{1}{2} \times 5 \times 5 \times 15 \times 15} \times \frac{1}{2} \times 15$$

$\text{,,} = \mathbf{424{\cdot}1\ lbs.\ per\ sq.\ inch.}$

EXAMPLE III.—A round steel spindle 10 inches long, and held at one end, revolves at the rate of 150 revolutions per minute round a vertical axis, to which the axis of the spindle is parallel

and from which it is 2 feet distant. The spindle has a uniformly distributed load, the whole revolving weight being 30 lbs. What should be the diameter of the spindle when the safe working stress of the material in tension or compression is taken at 25,000 lbs. per square inch? (S. & A. Hons. Exam., 1891.)

ANSWER.—The spindle in this problem may be likened to a beam fixed at one end and carrying a uniformly distributed load. The load being not the revolving weight of 30 lbs., but the centrifugal force of that weight due to its being whirled round at the rate of 150 revolutions per minute.

$$\text{Velocity of spindle, } = \frac{150 \times 2\pi \times 2}{60} = 10\,\pi \text{ ft. per sec.}$$

$$\text{Centrifugal force, } = \frac{30 \times (10 \times \pi)^2}{32 \times 2} = \frac{1500 \times \pi^2}{32} \text{ lbs.}$$

This force, multiplied by half the length of the spindle, gives us the bending moment at the fixed end of the spindle :—

$$\text{That is,} \qquad \text{B.M.} = \frac{1500 \times \pi^2}{32} \times \frac{10}{2} \text{ inch-lbs.}$$

If D be the diameter of the spindle in inches, then from Lecture XXII. we get :—

$$\text{The Moment of Inertia, } I = \frac{\pi}{64} D^4$$

$$\text{And the Modulus of Section, } Z = \frac{I}{\frac{D}{2}} = \frac{\pi}{32} D^3.$$

Now, fZ = B.M. ; and, f = 25,000 lbs. per sq. inch.

$$\therefore \quad 25{,}000 \times \frac{\pi}{32} D^3 = \frac{1500\,\pi^2}{32} \times \frac{10}{2}$$

$$\text{Or,} \qquad D^3 = 0{\cdot}3 \times \pi = 0{\cdot}94248$$

$$\text{Hence,} \qquad D = \sqrt[3]{0{\cdot}94248} = 0{\cdot}98 \text{ inch.}$$

EXAMPLE IV.—The section of a cast-iron girder, and the maximum safe tensile and compressive stresses being given, explain how to determine its moment of resistance to bending. The dimensions of the section of a cast-iron girder are the

following:—Top flange, 4 by $1\frac{1}{2}$ inches; bottom flange, 12 by $1\frac{3}{4}$ inches; web, 16 by $1\frac{1}{2}$ inches. Determine the moment of resistance, the greatest permissible tensile and compressive stresses being $2\frac{1}{2}$ and $7\frac{1}{2}$ tons per square inch respectively. If the girder be 20 feet long, and is supported at its two ends, find the greatest safe load which it will carry when uniformly distributed along its length. (S. and A. Hons. Exam., 1895.)

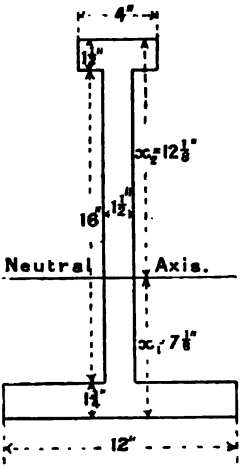

SECTION OF GIRDER.

ANSWER.—As this is an excellent example for showing the student how the R.M. of a girder section is calculated, we shall go into the matter in detail. Let the accompanying figure represent the cross-section in question.

We have first to find the position of the neutral axis N A, by writing down the sectional areas of the parts composing the figure, and taking moments about the lower edge.

Area of top	flange	$= 4 \times 1\frac{1}{2} =$	6 sq. in.
„	bottom „	$= 12 \times 1\frac{3}{4} =$	21 „
„	web	$= 16 \times 1\frac{1}{2} =$	24 „
∴	Total area of section	$=$	51 „

Then, since N A passes through the centre of area of the section, we have:—

$$51 \times x_1 = 6 \times 18\tfrac{1}{2} + 24 \times 9\tfrac{3}{4} + 21 \times \tfrac{7}{8} = 363\tfrac{3}{8}.$$

$$\therefore \qquad x_1 = \frac{363\frac{3}{8}}{51} = 7\tfrac{1}{8}.$$

And $\qquad x_2 = 19\tfrac{1}{4} - 7\tfrac{1}{8} = 12\tfrac{1}{8}.$

We calculate the value of I, the moment of inertia of the section about the neutral axis, by finding that for each of the parts into which the section is divided and taking their sum. As the neutral axis does not pass through the centre of any of

those parts, we shall have to employ Proposition I. of Lecture XXII., to which we again refer the student.

Remembering that the moment of inertia of a rectangular area about an axis through its centre of gravity is :—

$$\tfrac{1}{12}\,(\text{breadth}) \times (\text{depth})^3, \text{ we have:—}$$

For top flange, $I_t = \frac{1}{12} \times 4 \times (1\frac{1}{2})^3 + 6 \times (11\frac{3}{8})^2.$

" " " $= 1{\cdot}125 + 776{\cdot}343 = 777{\cdot}468.$

For bottom flange, $I_b = \frac{1}{12} \times 12 \times (1\frac{3}{4})^3 + 21 \times (6\frac{1}{4})^2.$

" " " $= 5{\cdot}359 + 820{\cdot}312 = 825{\cdot}671.$

For web, $I_w = \frac{1}{12} \times 1\frac{1}{2} \times (16)^3 + 24 \times (2\frac{5}{8})^2.$

" " $= 512{\cdot}0 + 165{\cdot}375 = 677{\cdot}375.$

$\therefore$ For whole section, $I = 777{\cdot}468 + 825{\cdot}671 + 677{\cdot}375 = \mathbf{2280{\cdot}5}.$*

To illustrate what we said about the moduli of unsymmetrical sections, we shall find both moduli for this example :—

$$\text{For tension, } Z_t = \frac{I}{x_1} = \frac{2280{\cdot}5}{7{\cdot}125} = \mathbf{320{\cdot}0}.$$

$$\text{For compression, } Z_c = \frac{I}{x_2} = \frac{2280{\cdot}5}{12{\cdot}125} = \mathbf{188{\cdot}0}.$$

The question gives as the greatest permissible values for :—

Tensile stress, $f_t = 2{\cdot}5$ tons per sqr. inch.

Compressive stress, $f_c = 7{\cdot}5$ " "

Since, R.M. $= Zf_{max.}$, we must take the lower of the two values of R.M. in fixing the load to be carried by the girder. These are:—

$$Z_t \times f_t = 320 \times 2{\cdot}5 = 800 \text{ inch-tons.}$$

And, $$Z_c \times f_c = 188 \times 7{\cdot}5 = 1410 \text{ inch-tons.}$$

$\therefore$ B.M. = R.M. = 800 inch-tons.

* Another and rather shorter method of finding I for this form of section is to (1) produce the sides of top and bottom flanges to meet the neutral axis N A, (2) calculate the moments of inertia of the two full rectangles thus formed, (3) subtract from their sum the moments of inertia of the four rectangular areas which are in excess of the section of the beam. All these moments may be found by the formula $I = \frac{1}{12} B \times D^3$, which will only require to be used four times as the blank rectangles on each side of the web are equal in pairs.

The girder will, therefore, safely carry a uniformly distributed load, given by the equation :—

$$\tfrac{1}{8}\, w\, L^2 = 800.$$

$$\therefore \qquad W = w\, L = \frac{8 \times 800}{20 \times 12} = 26\tfrac{2}{3} \text{ tons.}$$

This will make the maximum compressive stress

$$f_{c\ max.} = \frac{800}{188} = 4{\cdot}255 \text{ tons,}$$

instead of 7·5 as given; showing that the girder is not well designed.

In a properly proportioned section we should have :—

$$Z_t \times f_t = Z_c \times f_c.$$

Thin Wrought-Iron Girders.—In the case of wrought-iron girders where the flanges are thin compared with their distance apart, and where the bending resistance of the web is disregarded as a provision against the shearing force acting at the section, the formulæ for the moment of resistance are very simple.

Let A_t = Area of flange in tension.
" A_c = Area of flange in compression.
" H = Distance between centres of flanges.
" f_t = Mean stress in tension flange.
" f_c = Mean stress in compression flange.

Distance between centre of tension flange and the neutral axis is :—

$$y_t = \left(\frac{A_c}{A_t + A_c}\right) H;$$

and the distance between centre of compression flange and the neutral axis is :—

$$y_c = \left(\frac{A}{A_t + A_c}\right) H.$$

The moment of inertia of the flanges, with respect to the neutral axis, is :—

$$I = A_t \left(\frac{A_c}{A_t + A_c}\right)^2 H^2 + A_c \left(\frac{A_t}{A_t + A_c}\right)^2 H^2$$

$$\text{Or,} \quad I = \{A_t \times A_c^2 + A_c \times A_t^2\} \times \left(\frac{H}{A_t + A_c}\right)^2$$

$$\text{Since, } f = \frac{M}{I} y.$$

$$\therefore \quad f_t = \frac{M}{\{A_t \times A_c^2 + A_c \times A_t^2\}\left(\frac{H}{A_t + A_c}\right)^2} \times \left(\frac{A_c}{A_t + A_c}\right) H$$

$$\left.\begin{array}{ll} \text{Hence,} & f_t = \dfrac{M}{A_t \times H} \\ \text{Similarly,} & f_c = \dfrac{M}{A_c \times H} \end{array}\right\} \quad \ldots\ldots\ldots \quad \text{(VII)}$$

EXAMPLE V.—A wrought-iron riveted girder of I section has a top flange of 9 square inches in sectional area, and a bottom flange of 8 square inches. The distance between the centres of gravity of the flanges is 12 inches, and the ends of the beam rest on abutments, 16 feet apart. The girder being loaded uniformly with a load equal to 1 ton per lineal foot (including the weight of the beam). What would be the mean stress per square inch on the metal in each flange at the dangerous section? The resistance of the web to bending is neglected. (S. & A. Hons. Exam., 1892.)

ANSWER.—By "dangerous section" is here meant the middle section of the girder, where the maximum bending moment occurs. (See equation (XI_a) of Lecture XXXI.)

$$\text{Max. B.M.} = \frac{1}{8}\left(\frac{1}{12}\right) \times (16 \times 12)^2 = 32 \times 12 \text{ inch-tons.}$$

Hence, mean stress in tension flange,

$$f_t = \frac{32 \times 12}{8 \times 12} = 4 \text{ tons per square inch.}$$

And, mean stress in compression flange,

$$f_c = \frac{32 \times 12}{9 \times 12} = 3{\cdot}55 \text{ tons per square inch.}$$

Curvature and Deflection of Beams.—When we speak of the curvature or the deflection of a beam we mean that of its neutral surface.

If the beam is fixed at one end, we take the origin of co-ordinates at that end; but if supported or fixed symmetrically at both ends, we take it at the middle.

Let the co-ordinates of the neutral surface curve be denoted, as usual, by x and y, then the deflection of the beam at any distance x, from the origin will be measured by y and the tangent of its inclination to the horizon by $\frac{dy}{dx}$.

The equation of the curve into which the beam is bent will be:—

$$y = \varphi(x),$$

Where $\varphi(x)$ is a function of x to be determined for each particular case.

In treatises on the analytical geometry of plane curves it is shown that the general expression for radius of curvature is:—

$$\rho = \frac{\left\{1 + \left(\frac{dy}{dx}\right)^2\right\}^{\frac{3}{2}}}{\frac{d^2y}{dx^2}}.$$

Although of great importance, in the theory of beams $\frac{dy}{dx}$ is always such a small fraction, that its square becomes a perfectly negligible quantity in comparison with unity. We may, therefore, safely disregard the value of $\left(\frac{dy}{dx}\right)^2$ in the above formula, and write $\frac{d^2y}{dx^2} = \frac{1}{\rho}$.

But by equation (IV) of this Lecture we know that:—

$$\frac{1}{\rho} = \frac{M}{EI}. \quad \therefore \frac{d^2y}{dx^2} = \frac{M}{EI}. \quad . \quad . \quad . \quad . \text{ (VIII)}$$

In what follows we shall assume that the beam or girder is of uniform section so that I is constant, the more general cases where I varies being rather beyond the scope of this treatise.

We shall begin by working out the following example, which will form a good introduction to this rather mathematical part of our subject.

EXAMPLE VI.—Investigate a formula for calculating the amount of deflection of a beam supported at its ends and loaded uniformly. Find the deflection in a beam of timber of uniform rectangular section, 6 inches wide and 12 inches deep, the beam

being supported at its ends in a horizontal position on two walls 12 feet apart. There is to be taken into account a single concentrated load of 4,000 lbs. at the centre, and a uniformly distributed load of 2,500 lbs., the modulus of elasticity being 1,750,000 lbs. per square inch. (S. & A. Hons. Exam., 1891.)

ANSWER.—Taking the middle of the beam as the origin of co-ordinates, we have already proved (see equation (XI) in Lecture XXXI.) that the bending moment at x inches from this point, in the case of a beam L inches between supports, and loaded uniformly with w lbs. per inch-run, is :—

$$\text{B.M.} = \tfrac{1}{2} w (\tfrac{1}{4} L^2 - x^2) \text{ inch-lbs.}$$

Substituting this in formula (VIII) we get :—

$$\frac{d^2y}{dx^2} = \frac{w}{2EI} (\tfrac{1}{4} L^2 - x^2).$$

Now, multiplying both sides by dx, and integrating, we have :—

$$\frac{dy}{dx} = \frac{w}{2EI} \int (\tfrac{1}{4} L^2 - x^2)\, dx.$$

Or,
$$\frac{dy}{dx} = \frac{w}{2EI} (\tfrac{1}{4} L^2 x - \tfrac{1}{3} x^3).$$

This needs no correction because $\frac{dy}{dx} = 0$, when $x = 0$.

Integrating a second time, we get :—

$$y = \frac{w}{2EI} \int (\tfrac{1}{4} L^2 x - \tfrac{1}{3} x^3)\, dx.$$

Or,
$$y = \frac{w}{8EI} (\tfrac{1}{2} L^2 x^2 - \tfrac{1}{3} x^4). \quad . \quad . \quad . \quad . \quad . \quad . \quad \text{(IX)}$$

This also requires no correction, as x and y vanish together. Now, let Δ_1 denote the deflection of the beam for the distributed load :—

$$\Delta_1 = y, \text{ when } x = \tfrac{1}{2} L.$$

Or,
$$\Delta_1 = \frac{w}{8EI} \{\tfrac{1}{2} L^2 (\tfrac{1}{2} L)^2 - \tfrac{1}{3} (\tfrac{1}{2} L)^4\}.$$

$\therefore$
$$\Delta_1 = \frac{5\, w L^4}{384\, EI} \text{ inches.} \quad . \quad . \quad . \quad . \quad . \quad . \quad . \quad . \quad \text{(X)}$$

In the case of a beam carrying a single load of W lbs. at its

middle point, the bending moment due to that load at x inches from the middle point (Equation (VII) Lecture XXXI.) is :—

$$\text{B.M.} = \tfrac{1}{2}\,\text{W}\,(\tfrac{1}{2}\,\text{L} - x) \text{ inch-lbs.}$$

$$\therefore \qquad \frac{d^2 y}{d x^2} = \frac{\text{W}}{2\,\text{E}\,\text{I}}\,(\tfrac{1}{2}\,\text{L} - x).$$

The first integration of this equation gives :—

$$\frac{d\,y}{d\,x} = \frac{\text{W}}{2\,\text{E}\,\text{I}}\,(\tfrac{1}{2}\,\text{L}\,x - \tfrac{1}{2}\,x^2) = \frac{\text{W}}{4\,\text{E}\,\text{I}}\,(\text{L}\,x - x^2).$$

And the second integration :—

$$y = \frac{\text{W}}{4\,\text{E}\,\text{I}}\,(\tfrac{1}{2}\,\text{L}\,x^2 - \tfrac{1}{3}\,x^3). \quad . \quad . \quad . \quad . \quad . \quad . \quad \text{(XI)}$$

If Δ_2 be the total deflection in this case, then Δ_2 is the value of y when $x = \tfrac{1}{2}\,\text{L}$.

$$\therefore \qquad \Delta_2 = \frac{\text{W}}{4\,\text{E}\,\text{I}}\,\{\tfrac{1}{2}\,\text{L}\,(\tfrac{1}{2}\,\text{L})^2 - \tfrac{1}{3}\,(\tfrac{1}{2}\,\text{L})^3\}.$$

$$\text{Or,} \qquad \Delta_2 = \frac{\text{W}\,\text{L}^3}{48\,\text{E}\,\text{I}} \text{ inches.} \quad . \quad . \quad . \quad . \quad . \quad . \quad . \quad . \quad \text{(XII)}$$

If the beam carry both loads at the same time, as given in the question, then the total deflection due to the two loads will be :—

$$\Delta = \Delta_1 + \Delta_2.$$

$$\therefore \qquad \Delta = \frac{5\,w\,\text{L}^4}{384\,\text{E}\,\text{I}} + \frac{\text{W}\,\text{L}^3}{48\,\text{E}\,\text{I}}.$$

$$\text{Or,} \qquad \Delta = \frac{\text{L}^3}{48\,\text{E}\,\text{I}}\,(\tfrac{5}{8}\,w\,\text{L} + \text{W}).$$

The numerical data given are :—

$$\text{L} = 12 \times 12 \text{ inches.}$$

$$\text{I} = \tfrac{1}{12}\,b\,d^3 = \tfrac{1}{12} \times 6 \times 12^3 = 6 \times 12^2.$$

$$\text{W} = 4{,}000 \text{ lbs.}$$

$$w\,\text{L} = 2{,}500.$$

$$\text{And,} \qquad \text{E} = 1{,}750{,}000.$$

$$\therefore \qquad \Delta = \frac{(12 \times 12)^3}{48 \times 1{,}750{,}000 \times 6 \times 12^2}\,(\tfrac{5}{8} \times 2{,}500 + 4{,}000)$$

$$\Delta = 0{\cdot}2288 \text{ inches.}$$

Uniform Beam on Three Supports.—Suppose we are given a uniform beam resting on three supports all on the same level, to find the pressure on the middle support.

It is clear that if the middle support were taken away, the weight of the beam would cause it to bend down at the middle [as found above by equation (X)] through a distance

$$\Delta_1 = \frac{5\,w\,L^4}{384\,E\,I} \text{ inches.}$$

We have also seen by equation (XII) that a single concentrated load of W lbs. applied at the middle of the beam would produce an amount of deflection, $\Delta_2 = \frac{W\,L^3}{48\,E\,I}$ inches.

This gives us the upward deflection caused by the reaction of the central support if we put its value, P, instead of W in the equation.

The total deflection will be zero if all three supports are on the same level.

Then, $$\frac{P\,L^3}{48\,E\,I} = \frac{5\,w\,L^4}{384\,E\,I}.$$

Or, $$P = \tfrac{5}{8}\,w\,L.$$

The pressure on the middle support is thus seen to be $\frac{5}{8}$ of the weight of the beam; whilst the end supports each carry $\frac{3}{16}$ of the weight.

Uniform Beam Fixed at one End and Supported at the other.—If w be the weight of the beam in lbs. per inch-run and L its length in inches, then, we already know that at x inches from the fixed end, the

$$\text{B.M.} = \tfrac{1}{2}\,w\,(L - x)^2 \text{ inch-lbs.}$$

Putting this value of the B.M. in equation (VIII), we get:—

$$\frac{d^2 y}{d x^2} = \frac{w}{2\,E\,I}(L - x)^2 = \frac{w}{2\,E\,I}(L^2 - 2\,L\,x + x^2).$$

$$\therefore \quad \frac{d\,y}{d\,x} = \frac{w}{2\,E\,I}\int (L^2 - 2\,L\,x + x^2)\,d\,x$$

$$\text{,,} \quad = \frac{w}{2\,E\,I}\{L^2\,x - L\,x^2 + \tfrac{1}{3}\,x^3\}.$$

And, $$y = \frac{w}{2\,E\,I}\int\{L^2\,x - L\,x^2 + \tfrac{1}{3}\,x^3\}d\,x$$

$$y = \frac{w}{2\,E\,I}\{\tfrac{1}{2}\,L^2\,x^2 - \tfrac{1}{3}\,L\,x^3 + \tfrac{1}{12}\,x^4\}. \quad . \quad . \quad \text{(XIII)}$$

This last equation gives the droop of the beam at any distance x, from the fixed end. At the free end let Δ_1 be the value of y when $x = L$.

Then, $$\Delta_1 = \frac{w L^4}{8 E I} \text{ inches.} \quad . \quad . \quad . \quad . \quad . \quad . \quad \text{(XIV)}$$

Let P be the upward pressure in lbs., between the beam and a support placed under its free end. The bending moment, due to P, at x inches from the fixed end is $P(L - x)$ inch-lbs. Hence, the curvature produced by P will be :—

$$\frac{d^2 y}{d x^2} = \frac{P}{E I}(L - x).$$

$$\therefore \quad \frac{dy}{dx} = \frac{P}{E I}\int (L - x)\, d x = \frac{P}{E I}(L x - \tfrac{1}{2} x^2).$$

And, $$y = \frac{P}{E I}\int (L x - \tfrac{1}{2} x^2)\, d x = \frac{P}{2 E I}(L x^2 - \tfrac{1}{3} x^3). \quad . \quad \text{(XV)}$$

When $x = L$, let $y = \Delta_2$.

$$\therefore \quad \Delta_2 = \frac{P L^3}{3 E I} \text{ inches.} \quad . \quad . \quad . \quad . \quad . \quad . \quad \text{(XVI)}$$

If $\Delta_2 = \Delta_1$, the supported end will be raised to the same level as the fixed end.

Then, $$\frac{P L^3}{3 E I} = \frac{w L^4}{8 E I}.$$

Or, $$P = \tfrac{3}{8} w L \text{ lbs.}$$

This result shows that the pressure on the prop is equal to $\frac{3}{8}$ of the weight of the beam.

It will be instructive for the student to observe that this result might easily have been inferred from the previous case of a beam resting on three props.

In that case the part of the beam immediately over the middle support is in exactly the same condition as the fixed end of the beam in this case ; so that whatever is true of each half of the beam in the former case will here hold good for the whole beam. The pressure on the end supports is, therefore, identical in magnitude in each case ; because $\frac{3}{16}$ of the weight of the whole beam is the same thing as $\frac{3}{8}$ of the weight of each half.

Beam Fixed at Both Ends and Loaded at the Centre.—When a beam is fixed, or built horizontally into a wall at both ends, the fixing causes a bending moment which is constant all over the

beam. For the reaction of the left support in keeping the beam horizontal is equivalent to a force P, acting downwards at some distance l, to the left of that support, and an upward force P, at the support. The bending moment at the support is then :—

$$M_s = P \times l.$$

And, at any other point, E, of the beam, at a distance, z (less than half the span from the support), the B.M. caused by this reaction at the support is :—

$$B.M. = P(z + l) - Pz = Pl = M_s.$$

Consequently, the fixing at the ends causes a constant B.M. all over the beam, equal to that at the supports, in addition to that caused by the load (*but in the opposite direction*).

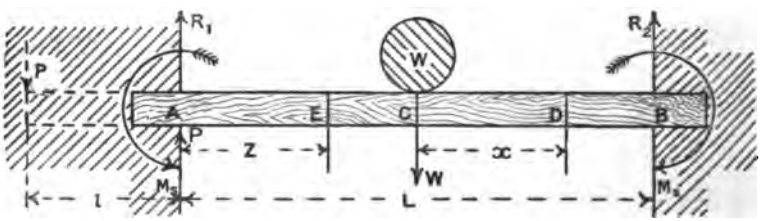

BEAM FIXED AT ENDS AND LOADED AT CENTRE.

Taking our origin of co-ordinates at C, the centre, and the undeflected axis, or neutral line of the beam, as our axis of x, we have, at a section D, distant x from C :—

$$B.M. = R_2(\tfrac{1}{2}L - x) - M_s = \tfrac{1}{2}W(\tfrac{1}{2}L - x) - M_s$$

Hence, from eqn. (VIII), $\left.\right\}$ $\dfrac{d^2y}{dx^2} = \dfrac{1}{EI}\{\tfrac{1}{2}W(\tfrac{1}{2}L - x) - M_s\}$

$$\therefore \qquad \frac{dy}{dx} = \frac{1}{EI}\{\tfrac{1}{4}W(Lx - x^2) - M_s x\}$$

The beam is horizontal at the centre and at the ends, therefore $\dfrac{dy}{dx}$ is zero when x is zero, and when $x = \tfrac{1}{2}L$.

$$\therefore \qquad 0 = \frac{1}{EI}\{\tfrac{1}{4}W(\tfrac{1}{2}L^2 - \tfrac{1}{4}L^2) - \tfrac{1}{2}M_s L\}$$

Or, $\qquad M_s = \tfrac{1}{8}WL.$

Inserting this value in the above equation for the B.M. we get :—

$$\text{B.M.} = \tfrac{1}{2}\text{W}\,(\tfrac{1}{2}\text{L} - x) - \tfrac{1}{8}\text{W L}$$

Or, $$\text{B.M.} = \tfrac{1}{2}\text{W}\,(\tfrac{1}{4}\text{L} - x) \quad . \quad . \quad . \quad . \quad \text{(XVII)}$$

At the centre, $$\text{B.M.} = \tfrac{1}{2}\text{W} \,.\, \tfrac{1}{4}\text{L} = \tfrac{1}{8}\text{W L} = \text{M}_s$$

$\therefore$ $$\text{Maximum B.M.} = \text{M}_s = \tfrac{1}{8}\text{W L}. \quad . \quad . \quad . \quad . \quad . \quad \text{(XVIII)}$$

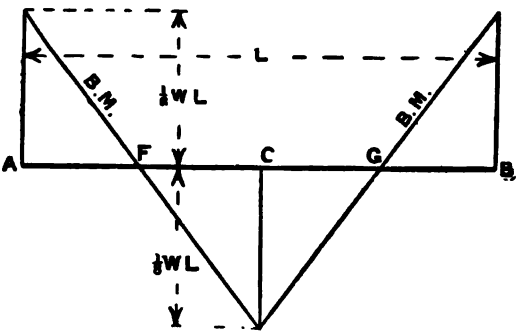

B.M. Diagram for Beam Fixed at Ends and Loaded at Centre.

We thus see that, in this case the fixing of the ends reduces the maximum B.M. to half what it would be with free ends, and that this maximum B.M. occurs both at the centre and the ends.

The B.M. diagram is similar to what we had for a beam simply supported, but the base line is shifted half way down the diagram, so that it is crossed at F and G by the lines representing the B.M. It will be seen from equation (XVII) that the B.M. is zero where $x = \frac{1}{4}$ L, and that it is positive on one side of this point, and negative on the other. This is one of the points where the B.M. curve cuts the base line, and it is called a *point of inflection*, because the beam is straight just at that point and the curvature changes sign. There is, of course, another point of inflection at the distance $\frac{1}{4}$ L on the other side of the centre.

In large girder bridges that part of the span between the two points of inflection is made separate from the remainder and rests on rollers at these points. This allows freedom of expansion without reducing the strength of the bridge.

Integrating the value of $\frac{dy}{dx}$ we get :—

$$y = \frac{1}{\text{E I}}\,\{\tfrac{1}{4}\,\text{W}\,(\tfrac{1}{2}\,\text{L}\,x^2 - \tfrac{1}{3}\,x^3) - \tfrac{1}{16}\,\text{W L}\,x^2\}.$$

Therefore, at the ends, where $x = \frac{1}{2}L$:—

$$y = \frac{1}{EI}\left\{\frac{1}{4}W\left(\frac{L^3}{8} - \frac{L^3}{24}\right) - \frac{1}{16}W\frac{L^3}{4}\right\} = \frac{WL^3}{192EI}.$$

Hence, the difference of level between the centre and the ends is :—

$$\Delta = \frac{WL^3}{192EI} \quad . \quad . \quad . \quad . \quad . \quad . \quad . \quad . \quad . \quad (XIX)$$

This is only one-fourth of the deflection when the beam simply rested on its supports (Equation XII), so that the beam is now four times as stiff.

Beam Fixed at Both Ends and Loaded Uniformly.—Taking axes as before, the B.M. at any section, D, is :—

$$\text{B.M.} = R_2\left(\tfrac{1}{2}L - x\right) - \tfrac{1}{2}w\left(\tfrac{1}{2}L - x\right)^2 - M_s.$$

$$\text{Or, B.M.} = \tfrac{1}{2}wL\left(\tfrac{1}{2}L - x\right) - \tfrac{1}{2}w\left(\tfrac{1}{4}L^2 - Lx + x^2\right) - M_s.$$

$$\therefore \quad \frac{d^2y}{dx^2} = \frac{1}{EI}\left\{\tfrac{1}{2}w\left(\tfrac{1}{4}L^2 - x^2\right) - M_s\right\}.$$

$$\text{Or,} \quad \frac{dy}{dx} = \frac{1}{EI}\left\{\tfrac{1}{2}w\left(\tfrac{1}{4}L^2x - \tfrac{1}{3}x^3\right) - M_s x\right\}.$$

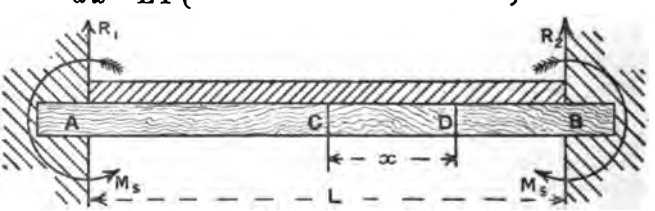

BEAM FIXED AT BOTH ENDS AND LOADED UNIFORMLY.

In this case also, $\frac{dy}{dx}$ is zero when x is zero, and when $x = \frac{1}{2}L$.

$$\therefore \quad 0 = \tfrac{1}{2}wL^3\left(\tfrac{1}{8} - \tfrac{1}{24}\right) - \tfrac{1}{2}M_s L.$$

$$\text{Or,} \quad M_s = \frac{wL^2}{12} = \frac{WL}{12}.$$

$$\text{Hence,} \quad \text{B.M.} = \tfrac{1}{2}w\left(\tfrac{1}{4}L^2 - x^2\right) - \tfrac{1}{12}wL^2.$$

$$\text{Or,} \quad \text{B.M.} = \tfrac{1}{2}w\left(\tfrac{1}{12}L^2 - x^2\right). \quad . \quad . \quad . \quad . \quad . \quad . \quad (XX)$$

At the centre, where $x = 0$, the B.M. is :—

$$M_c = \frac{wL^2}{24} = \frac{WL}{24} = \tfrac{1}{2}M_s.$$

This is only half of that at the support. Hence, the greatest bending moment occurs at the support, and its value is :—

$$\text{Maximum B.M.} = \tfrac{1}{12} w L^2 = \tfrac{1}{12} W L. \quad . \quad . \quad (XXI)$$

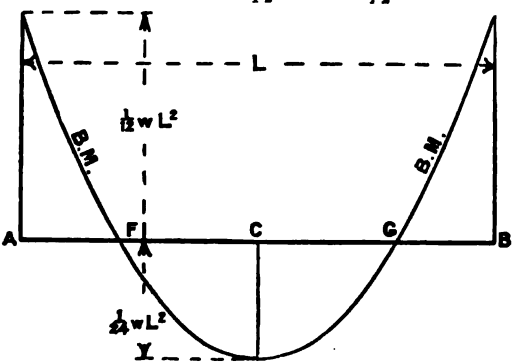

B.M. Diagram for Beam Fixed at both Ends and Loaded Uniformly.

The points of inflection occur where $x^2 = \frac{1}{12} L^2$ or $x = \pm \frac{L}{2\sqrt{3}}$.

By integrating the above value of $\frac{dy}{dx}$:—

$$y = \frac{1}{EI}\left\{ \tfrac{1}{2} w \left(\tfrac{1}{3} L^2 x^2 - \tfrac{1}{12} x^4\right) - \tfrac{1}{12} w L^2 \frac{x^2}{2} \right\} = \frac{w}{48\,EI}(L^2 x^2 - 2x^4).$$

Putting $x = \frac{L}{2}$ we obtain the amount by which the centre of the beam is deflected by the load, viz. :—

$$\Delta = \frac{w}{48\,EI}\left(\frac{L^4}{4} - \frac{L^4}{8}\right) = \frac{w L^4}{384\,EI} = \frac{W L^3}{384\,EI} \quad . \quad . \quad (XXII)$$

We thus see that, by fixing the ends horizontally for this manner of loading, the strength of the beam is increased in the ratio 3 : 2, and its stiffness in the ratio 5 : 1.

When the span of the beam is small, it may be designed wholly from considerations of strength; but when the span is great a beam may be strong enough, and yet not suitable, because it yields too much when the load is put on it. It then becomes necessary to take the stiffness into account by using one of the formulæ we have found for the deflection. The greatest deflection usually allowed in beams is 1 inch in 100 feet, or $\frac{1}{1200}$ of the span.

In the tables below we give a summary of these results, showing the relation between them.

TABLE III.—STRENGTH AND STIFFNESS OF BEAMS UNDER A TOTAL LOAD OF W LBS.

No.	MANNER OF SUPPORTING AND LOADING.	Maximum Bending Moment = M.	Relative Strength.	Deflection in Terms of W.	Deflection in Terms of M.	Deflection in Terms of Stress.	Relative Stiffness under same Load.
I.	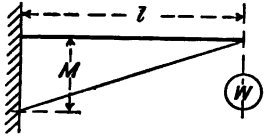 CANTILEVER LOADED AT END.	Wl	$\frac{1}{4}$	$\frac{1}{3} \cdot \frac{Wl^3}{EI}$	$\frac{1}{3} \cdot \frac{Ml^2}{EI}$	$\frac{1}{3} \cdot \frac{fl^2}{Ey}$	$\frac{1}{16}$
II.	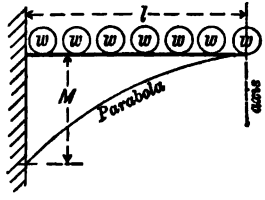 CANTILEVER LOADED UNIFORMLY.	$\frac{Wl}{2}$	$\frac{1}{2}$	$\frac{1}{8} \cdot \frac{Wl^3}{EI}$	$\frac{1}{4} \cdot \frac{Ml^2}{EI}$	$\frac{1}{4} \cdot \frac{fl^2}{Ey}$	$\frac{1}{8}$
III.	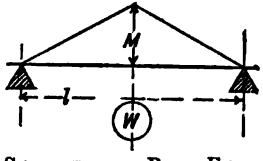 SUPPORTED AT BOTH ENDS. LOADED AT CENTRE.	$\frac{Wl}{4}$	1	$\frac{1}{48} \cdot \frac{Wl^3}{EI}$	$\frac{1}{12} \cdot \frac{Ml^2}{EI}$	$\frac{1}{12} \cdot \frac{fl^2}{Ey}$	1

TABLE III.—STRENGTH AND STIFFNESS OF BEAMS UNDER A TOTAL LOAD OF W LBS. (*continued*).

No.	MANNER OF SUPPORTING AND LOADING.	Maximum Bending Moment = M	Relative Strength.	Deflection in Terms of W.	Deflection in Terms of M.	Deflection in Terms of Stress.	Relative Stiffness under same Load.
IV.	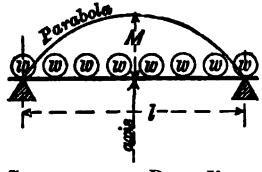 SUPPORTED AT BOTH ENDS. LOADED UNIFORMLY.	$\frac{Wl}{8}$	2	$\frac{5}{384} \cdot \frac{Wl^3}{EI}$	$\frac{5}{48} \cdot \frac{Ml^2}{EI}$	$\frac{5}{48} \cdot \frac{fl^2}{Ey}$	$\frac{8}{5}$
V.	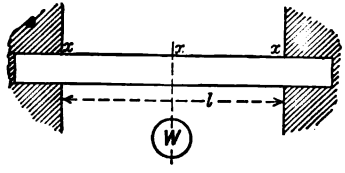 FIXED AT ENDS. LOADED AT CENTRE.	$\frac{Wl}{8}$	2	$\frac{1}{192} \cdot \frac{Wl^3}{EI}$	$\frac{1}{24} \cdot \frac{Ml^2}{EI}$	$\frac{1}{24} \cdot \frac{fl^2}{Ey}$	4
VI.	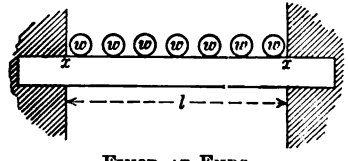 FIXED AT ENDS. LOADED UNIFORMLY.	$\frac{Wl}{12}$	3	$\frac{1}{384} \cdot \frac{Wl^3}{EI}$	$\frac{1}{32} \cdot \frac{Ml^2}{EI}$	$\frac{1}{32} \cdot \frac{fl^2}{Ey}$	8

TABLE III.—STRENGTH AND STIFFNESS OF BEAMS UNDER A TOTAL LOAD OF W LBS.

No.	MANNER OF SUPPORTING AND LOADING.	Maximum Bending Moment = M.	Relative Strength.	Deflection in Terms of W.	Deflection in Terms of M.	Deflection in Terms of Stress.	Relative Stiffness under same Load.
I.	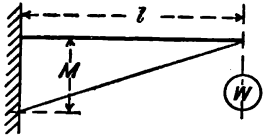 CANTILEVER LOADED AT END.	Wl	$\frac{1}{4}$	$\frac{1}{3} \cdot \frac{Wl^3}{EI}$	$\frac{1}{3} \cdot \frac{Ml^2}{EI}$	$\frac{1}{3} \cdot \frac{fl^2}{Ey}$	$\frac{1}{16}$
II.	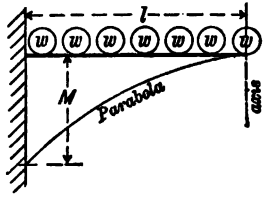 CANTILEVER LOADED UNIFORMLY.	$\frac{Wl}{2}$	$\frac{1}{2}$	$\frac{1}{8} \cdot \frac{Wl^3}{EI}$	$\frac{1}{4} \cdot \frac{Ml^2}{EI}$	$\frac{1}{4} \cdot \frac{fl^2}{Ey}$	$\frac{1}{8}$
III.	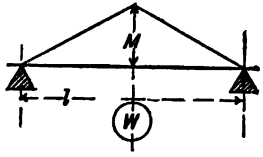 SUPPORTED AT BOTH ENDS. LOADED AT CENTRE.	$\frac{Wl}{4}$	1	$\frac{1}{48} \cdot \frac{Wl^3}{EI}$	$\frac{1}{12} \cdot \frac{Ml^2}{EI}$	$\frac{1}{12} \cdot \frac{fl^2}{Ey}$	1

TABLE III.—STRENGTH AND STIFFNESS OF BEAMS UNDER A TOTAL LOAD OF W LBS. (*continued*).

No.	MANNER OF SUPPORTING AND LOADING.	Maximum Bending Moment = M	Relative Strength.	Deflection in Terms of W.	Deflection in Terms of M.	Deflection in Terms of Stress.	Relative Stiffness under same Load.
IV.	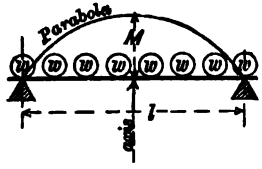 SUPPORTED AT BOTH ENDS. LOADED UNIFORMLY.	$\frac{Wl}{8}$	2	$\frac{5}{384} \cdot \frac{Wl^3}{EI}$	$\frac{5}{48} \cdot \frac{Ml^2}{EI}$	$\frac{5}{48} \cdot \frac{fl^2}{Ey}$	$\frac{8}{5}$
V.	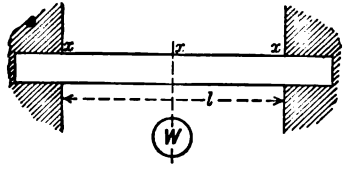 FIXED AT ENDS. LOADED AT CENTRE.	$\frac{Wl}{8}$	2	$\frac{1}{192} \cdot \frac{Wl^3}{EI}$	$\frac{1}{24} \cdot \frac{Ml^2}{EI}$	$\frac{1}{24} \cdot \frac{fl^2}{Ey}$	4
VI.	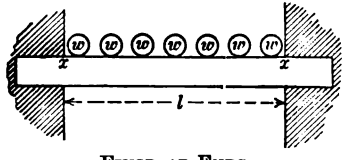 FIXED AT ENDS. LOADED UNIFORMLY.	$\frac{Wl}{12}$	3	$\frac{1}{384} \cdot \frac{Wl^3}{EI}$	$\frac{1}{32} \cdot \frac{Ml^2}{EI}$	$\frac{1}{32} \cdot \frac{fl^2}{Ey}$	8

TABLE III.—STRENGTH AND STIFFNESS OF BEAMS UNDER A TOTAL LOAD OF W LBS.

No.	MANNER OF SUPPORTING AND LOADING.	Maximum Bending Moment = M.	Relative Strength.	Deflection in Terms of W.	Deflection in Terms of M.	Deflection in Terms of Stress.	Relative Stiffness under same Load.
I.	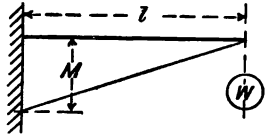 CANTILEVER LOADED AT END.	Wl	$\frac{1}{4}$	$\frac{1}{3} \cdot \frac{Wl^3}{EI}$	$\frac{1}{3} \cdot \frac{Ml^2}{EI}$	$\frac{1}{3} \cdot \frac{fl^2}{Ey}$	$\frac{1}{16}$
II.	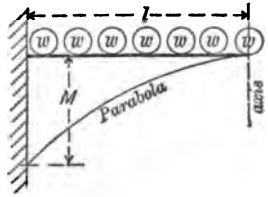 CANTILEVER LOADED UNIFORMLY.	$\frac{Wl}{2}$	$\frac{1}{2}$	$\frac{1}{8} \cdot \frac{Wl^3}{EI}$	$\frac{1}{4} \cdot \frac{Ml^2}{EI}$	$\frac{1}{4} \cdot \frac{fl^2}{Ey}$	$\frac{1}{8}$
III.	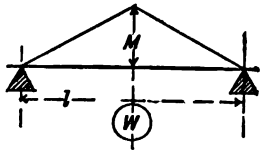 SUPPORTED AT BOTH ENDS. LOADED AT CENTRE.	$\frac{Wl}{4}$	1	$\frac{1}{48} \cdot \frac{Wl^3}{EI}$	$\frac{1}{12} \cdot \frac{Ml^2}{EI}$	$\frac{1}{12} \cdot \frac{fl^2}{Ey}$	1

TABLE III.—STRENGTH AND STIFFNESS OF BEAMS UNDER A TOTAL LOAD OF W LBS. (*continued*).

No.	MANNER OF SUPPORTING AND LOADING.	Maximum Bending Moment = M	Relative Strength.	Deflection in Terms of W.	Deflection in Terms of M.	Deflection in Terms of Stress.	Relative Stiffness under same Load.
IV.	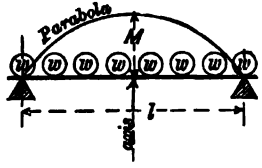 SUPPORTED AT BOTH ENDS. LOADED UNIFORMLY.	$\frac{Wl}{8}$	2	$\frac{5}{384} \cdot \frac{Wl^3}{EI}$	$\frac{5}{48} \cdot \frac{Ml^2}{EI}$	$\frac{5}{48} \cdot \frac{fl^2}{Ey}$	$\frac{8}{5}$
V.	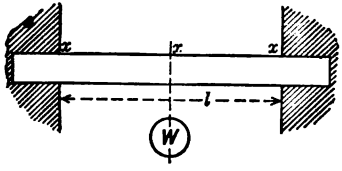 FIXED AT ENDS. LOADED AT CENTRE.	$\frac{Wl}{8}$	2	$\frac{1}{192} \cdot \frac{Wl^3}{EI}$	$\frac{1}{24} \cdot \frac{Ml^2}{EI}$	$\frac{1}{24} \cdot \frac{fl^2}{Ey}$	4
VI.	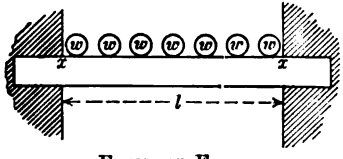 FIXED AT ENDS. LOADED UNIFORMLY.	$\frac{Wl}{12}$	3	$\frac{1}{384} \cdot \frac{Wl^3}{EI}$	$\frac{1}{32} \cdot \frac{Ml^2}{EI}$	$\frac{1}{32} \cdot \frac{fl^2}{Ey}$	8

The quantities in the sixth column are obtained by substituting the value of the maximum B.M. given by the third column in the fifth, and for those in the seventh we have put the value of M $\left(\text{viz., } \frac{fI}{y}\right)$ found in equation (V).

We also print for reference* a table of the strengths of materials and of the moduli of different sections.

* From Seaton & Rounthwaite's *Pocket Book of Marine Engineering Rules and Tables*, which may be consulted for other cases of beams; or Unwin's *Machine Design*, Part I.

STRENGTHS, &c., OF MATERIALS (SUMMARY).

Material.	Ultimate Tensile Strength. lbs. per square inch.	Elastic Strength. lbs. per square inch.	Elongation per cent., when broken by Tensile Stress.
Cast-iron (ordinary good)	18,000	11,000	...
,, (Admiralty), .	not less than 20,160	...	...
Wrought-iron bars (ordinary good), . .	54,000	29,000	15 °/₀ in 8 ins.
Yorkshire plate—			
With grain, . .	54,000	26,000	20 °/₀ ,,
Across ,, . .	49,000	...	14 °/₀ ,,
Staffordshire plate—			
With grain, . .	50,000	24,000	12 °/₀ ,,
Across ,, . .	41,000	...	8 °/₀ ,,
Iron forgings—			
Large, ...	45,000	...	9 °/₀ ,,
Small, ...	50,000	...	13 °/₀ ,,
Steel castings (ordinary good), ...	67,000	35,000	10 °/₀ ,,
Steel castings (Admiralty)	not less than 63,000	...	not less than 13½-18½ °/₀ in 2 ins.
,, (Lloyd's), .	not exceeding 67,000	...	not less than 10 °/₀ in 8 ins.
Steel boiler plate—			
(Ordinary good), .	65,000	36,000	20 °/₀ ,,
(Admiralty) internal,	not exceeding 60,480	...	20 °/₀ ,,
,, shell, .	60,480-67,200	not less than 31,360	...
(B. of T.) internal, .	58,240-67,200	...	...
,, shell, .	60,480-71,680	...	18 °/₀ in 10 ins.
Lloyd's, ...	58,240-67,200	...	not less than 20 °/₀ in 8 ins.
Steel forgings (Admiralty)	62,720-78,400	34,500 to 43,120	28 °/₀ to 24 °/₀ in 2 ins.
Sheet copper, . .	30,000	5,600	35 °/₀ in 8 ins.
Copper wire (annealed),	40,000	...	...
Gun-metal (ordinary good).	27,000	6,500	10 °/₀ in 2 ins.
Gun-metal (Admiralty),	31,000	...	...
Phosphor bronze (cast),	35,000	19,000	12 °/₀ in 2 ins.
Manganese bronze ,, .	55,000	...	10 °/₀ ,,
,, (rolled),	67,000	...	20 °/₀ ,,
Muntz metal, . .	50,000	30,000	30 °/₀ ,,
Naval brass, . . .	54,000	24,000	25 °/₀ in 8 ins.

Moment of Inertia, Modulus, &c., of some Sections.

The plane of bending is supposed perpendicular to plane of paper, and parallel to side of page.

Form of Section.	Area of Section. A	Moment of Inertia of Section about Axis through Centre of Gravity. I	Square of rads. of gyration of Section. $\rho^2 = \frac{I}{A}$	"Modulus" of Section. $Z = \frac{I}{y}$
	s^2	$\frac{s^4}{12}$	$\frac{s^2}{12}$	$\frac{s^3}{6}$
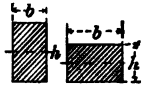	bh	$\frac{bh^3}{12}$	$\frac{h^2}{12}$	$\frac{bh^2}{6}$
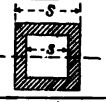	$S^2 - s^2$	$\frac{S^4 - s^4}{12}$	$\frac{S^2 + s^2}{12}$	$\frac{1}{6}\left(\frac{S^4 - s^4}{S}\right)$
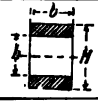	$b(H - h)$	$\frac{b(H^3 - h^3)}{12}$	$\frac{H^2 + hH + h^2}{12}$	$\frac{b(H^3 - h^3)}{6H}$
	$\cdot 7854 d^2$	$\cdot 0491 d^4$	$\frac{d^2}{16}$	$\cdot 0982 d^3$
	$\cdot 7854 (D^2 - d^2)$	$\cdot 0491 (D^4 - d^4)$	$\frac{D^2 + d^2}{16}$	$\cdot 0982\left(\frac{D^4 - d^4}{D}\right)$

MOMENT OF INERTIA, MODULUS, &c., OF SOME SECTIONS—*Continued.*

Form of Section.	Area of Section. A	Moment of Inertia of Section about Axis through Centre of Gravity. I	Square of rads. of gyration of Section. $\rho^2 = \frac{I}{A}$	"Modulus" of Section. $Z = \frac{I}{y}$
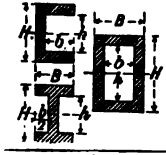	$BH - bh$	$\frac{BH^3 - bh^3}{12}$	$\frac{1}{12}\left(\frac{BH^3 - bh^3}{BH - bh}\right)$	$\frac{BH^3 - bh^3}{6H}$
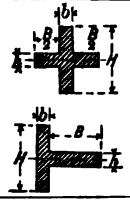	$Bh + bH$	$\frac{Bh^3 + bH^3}{12}$	...	$\frac{Bh^3 + bH^3}{6H}$
	$BH - bh$	$\frac{(BH^2 - bh^2)^2 - 4BHbh(H - h)^2}{12(BH - bh)}$	...	$\frac{(BH^2 - bh^2)^2 - 4BHbh(H - h)^2}{6(BH^2 + bh^2 - 2bHh)}$

LECTURE XXXII.—QUESTIONS.

1. A wrought-iron flanged girder is required to support a travelling load of 50 tons, the distance between the supports being 40 feet. The stress comes upon the girder at two points, the wheels on the traveller being 10 feet apart. What section of girder will be required to afford the necessary strength, presuming that the ultimate strength of the girder is six times that of the greatest stress to which it will be subjected?

2. Prove the law which governs the transverse strength of a beam of timber when supported at both ends and loaded at the centre. How are the constants required for applying this law arrived at?

3. A bar of wood, 7 feet long and 2 inches square, is supported at both ends, and is broken by a weight of 500 lbs. suspended at the centre. What weight in pounds will a rectangular bar of the same material, supported and loaded in like manner, sustain, when its length is 8 feet, its breadth 2½ inches, and its depth 4 inches? *Ans.* 2187·5 lbs.

4. A rectangular beam of fir, of uniform section throughout, is supported horizontally on two walls 15 feet apart, and has to carry a load of 1¼ tons at 5 feet from one of the walls. The width of the beam is 5 inches; find its depth, taking the breaking load at four times the safe load. How much should the depth of the beam be increased, the breadth remaining constant, if the load were shifted from its original position to the centre of the beam, the breaking weight of a beam of fir 15 inches long, 1 inch broad, and 1 inch deep, supported at both ends and loaded in the middle, being taken at 360 lbs.? *Ans.* 8·9 inches; ½ inch.

5. A solid rectangular girder, 3 inches deep and 2 inches broad, is supported at both ends on supports 5 feet apart. It is loaded with a uniformly distributed load, including its own weight, of 10 cwts. per foot run. What is the maximum intensity of stress at the outer fibres?

6. If two cast-iron beams—one circular in section and 2·73 inches in diameter, the other of rectangular section, 3 inches broad and 2 inches deep—be each supported at two points 20 inches apart, and loaded at the centre with a load of 2 tons; what will be the maximum intensity of stress produced in each case?

7. A beam of fir is built into a wall at one end, and projects 6 feet from the wall. The width of the beam is 4 inches; find its depth to bear safely a load of 1,200 lbs. uniformly distributed along its length. Assume that a bar of fir 1 foot long, 1 inch broad, and 1 inch deep, will break under a load of 125 lbs. when fixed at one end and loaded at the other end, and that the safe load is ⅓ the breaking load. *Ans.* 6 inches.

8. What must be the breadth in inches of an oak cantilever or overhanging beam, 6 feet long and 9 inches deep, in order to carry a load of ½ ton at its extremity, and how much must its breadth be increased in order that it may carry an additional load of ½ ton uniformly distributed over its length? The actual stress is not to exceed ¼ of the breaking stress, and the breaking weight of an oak cantilever 6 inches long, 1 inch deep, and 1 inch broad, is 280 lbs. *Ans.* 2·37 inches; 1·18 inches.

9. A beam of fir supported at each end is inclined at an angle of 60° to the horizon, and is loaded at the centre of its length with a weight of 1 ton. The length of the beam is 10 feet, and its breadth is 2 inches, find the depth; the breaking load on the centre of a beam 1 foot long, 1 inch

broad, and 1 inch deep, and supported at the ends in a horizontal position, being 450 lbs. *Ans.* 3·527 inches.

10. A cast-iron cantilever or overhanging beam of T-section is 6 feet long, and 9 inches deep, the top flange being 6 inches wide. The beam has to carry, with safety, at its end a load of 1 ton, together with a distributed load of 1 ton over its length. Find the thickness of the top flange, the tensile breaking strength of cast-iron being 8 tons per square inch, and the admissible load for a safe stress being one-fourth the breaking load. *Ans.* 1 inch.

11. Find the greatest load that may be uniformly distributed on a cast-iron girder having top and bottom flanges united by a web of the following dimensions—width of upper flange 3 inches, of lower flange 9 inches, total depth 12 inches, thickness of each flange and of the web being 1 inch, distance between the points of support 10 feet—when the greatest admissible stress in the compression flange is 3 tons per square inch, and that in the tension flange is 1½ tons per square inch. *Ans.* 9·9 tons.

12. Make a diagram of a flanged cast-iron girder to carry a load of 12 tons in the centre, the distance between the points of support being 20 feet. What should you make the depth of the beam, and what should be the sectional area of the top and bottom flanges respectively?

13. A rolled steel girder has a mean depth of 10 inches, the top and bottom flanges are each 6 inches wide, and the metal in the flanges and webs is ½ inch in thickness throughout. If the breaking strength of the material be taken as 40 tons to the square inch of section for both tension and compression, then (using 4 as a factor for safety) what would be the maximum safe load uniformly distributed over such a girder, supposing it to be supported at each end, the supports being 12 feet apart? Also make a diagram showing the distribution of the shearing stress in the middle transverse section. (S. & A. Hons. Exam., 1890.)

14. A rectangular beam of timber is supported at both ends, and loaded by a weight in the centre. Make the necessary calculations for measuring the strength of the beam to resist breaking. For a bar of larch 6 feet long by 2 inches square, supported as above, the breaking weight is 515 lbs.; taking this datum, you are required to solve the following question:—A cistern containing 2 tons of water rests on two cantilevers of larch, each 4 feet long and 5 inches in depth; find the breadth of each cantilever. *Ans.* 1·85 inches.

15. A cast-iron beam of rectangular section, and having its lowest side horizontal, is supported at both ends. What difference should you make in the upper outline according as the load is evenly distributed or collected in the centre?

16. A beam will safely carry a stationary load of 5 tons with a deflection of 2 inches, from what height may a weight of 200 lbs. be let drop upon the same beam without deflecting it to a greater extent? (S. & A. Exam., 1887.) *Ans.* 56 inches.

17. A steady load of 10 tons, suspended at the centre of a beam, deflects it through ⅜ inch. From what height would a weight of 300 lbs. require to fall in order to produce a like deflection when dropping on the beam? (S. & A. Exam., 1891.) *Ans.* 22·7 inches.

18. A cylindrical iron beam is 15 inches in its external diameter, and the metal is 1½ inches in thickness. The beam is fixed at the two ends, and is 35 feet between the supports; find the greatest load uniformly distributed that the beam will bear, the greatest safe stress on the metal being 9,000 lbs. per square inch. (S. & A. Hons. Exam., 1894.)

19. Compare the resistance to bending of a wrought-iron I section beam

when the beam is placed like this I, and like this ⊢. The flanges of the beam are each 6 inches wide and 1 inch thick, and the web is $\frac{3}{4}$ inch thick and measures 8 inches between the flanges. (Adv. S. & A. Exam., 1897.)

20. A horizontal bar of round iron, 1 inch diameter, 6 feet long, hinged at the ends, is subjected to equal and opposite pushing forces of 1,000 lbs. at its ends, and a load of 10 lbs. is hung at the middle so that it is both a beam and a strut. Find the greatest stress anywhere. $E = 29 \times 10^6$ lbs. per square inch. (S. & A. Hons. Exam., 1897.)

21. Draw the bending moment diagrams, and state the maximum bending moments for the six standard cases of loading and supporting a beam of the same length, same load. (1) Fixed at one end, loaded at the other. (2) Fixed at one end, loaded uniformly. (3) Supported at the ends, loaded in the middle. (4) Supported at the ends, loaded uniformly. (5) Fixed at the ends, loaded in the middle. (6) Fixed at the ends, loaded uniformly. (Adv. S. & A. Exam., 1897.)

22. A uniform beam is fixed at its ends, which are 20 ft. apart. A load of 5 tons in the middle; loads of 2 tons each at 5 ft. from the ends. Find the diagram of bending moment and prove your rule. State what the maximum bending moment is, and where are the points of inflexion. (Hons. S. & A. Exam., 1897.)

23. A rectangular beam, loaded in the middle, supported at the ends; find the shear stress at any point in any section. Find the deflection at the middle, and distinguish between the parts due to ordinary bending and to shear. (S. & A. Hons. Exam., Part II., 1898.)

24. What occurs at the cross-section of a horizontal beam, carrying vertical loads? Where is the neutral line? What is the value of the stress at any place? What is meant by *bending moment?* Describe any model which illustrates, however roughly, what occurs at a section of the beam. (S. & A. Adv. Exam., 1898.)

The following is a list of books on the Strength of Materials:—

Experimental Engineering, by Rolla C. Carpenter, C.E. (Chapman & Hall, London, 1895.)

Theory of Structures and Strength of Materials, by Henry T. Bovey, M.A., D.C.L. (John Wiley & Sons, New York.)

The Practical Strength of Beams. Paper by B. Baker. (Proc. Inst. C E., vol. lxii., p. 251.)

Mechanical Engineering Materials, by E. C. R. Marks. (Technical Publishing Co., Manchester.)

Strength and Properties of Materials, by W. G. Kirkcaldy, London.

Strength and Determination of the Dimensions of Structures of Iron and Steel, by J. J. Weyrauch, translated by A. J. Du Bois. (New York, 1891.)

Strength of Materials and Structures, by Sir J. Anderson. (Longmans, Green & Co., 1892.)

PART VI.—HYDRAULICS AND HYDRAULIC MACHINERY.

LECTURE XXXIII.

HYDROSTATICS—HYDRAULIC MACHINES.

CONTENTS.—Hydraulics—Fluids—Viscosity—Transmission of Pressure by a Fluid—Pressure of a Heavy Fluid—Head—Pressure on an Immersed Surface—Examples I., II., III., and IV.—Centre of Pressure—Centre of Pressure on a Rectangle—Triangle—Circle—Example V.—Energy of Still Water—Common Suction Pump—Belt-driven Suction Pump—Example VI.—Air Pump—Single-acting Force Pump—Single-acting Force Pump with Ball Valves—Force Pump with Air Vessel—Continuous Delivery Pumps without Air Vessels—Double-acting Force Pump—Double-acting Circulating Pump—Worthington Steam Pump—Pulsometer Pumps—Roots' Blower—Bramah's Hydraulic Press—Examples VII. and VIII.—Hydraulic Flanging Press—Hydraulic Jack—Examples IX., X., and XI.—Hydraulic Bear—Lead-covering Cable Press—Hydraulic Accumulator—Example XII.—Hydraulic Cranes—Hydraulic Wall Crane—Movable Jigger Crane—Double Power Hydraulic Crane—Hydraulic Capstan—Questions.

Hydraulics.—In its widest sense, the term "Hydraulics" is given to the study of the mechanical properties of fluids and their application to practical purposes. In a more restricted sense, it refers to the science of the pressure and flow of water and their applications in engineering. It is divided into two sections:—**Hydrostatics**, the science of fluids at rest; and **Hydrokinetics**, the science of fluids in motion.

Fluids.—In many investigations it is necessary for simplicity to assume that we are dealing with a *perfect fluid;* that is, one which possesses the following property:—

DEFINITION.—**A fluid is a substance which offers no resistance to a continuous change of shape.**

There are two kinds of fluids—those which are practically incompressible, termed *liquids;* and those which are easily compressed, called *gases* and *vapours.* We know of no substance which completely fulfils the above definition; but water, many other liquids, and all gases, so nearly comply with it, that for many purposes we may, in practice, consider them as perfect fluids.

Viscosity.—Ordinary fluids, however, do offer some resistance to a change of shape, and the property in virtue of which they do so is called the *viscosity* of the fluid. A substance, such as syrup, which offers considerable resistance to a rapid change of form, but which goes on changing its shape so long as any deforming forces are applied to it, however small these forces may be, is usually called a *viscous fluid*. This term, strictly speaking, applies to all fluids, since all have some viscosity. It should, however, be noted that even the most mobile fluid will offer an appreciable resistance to a *sudden* deformation, because parts of it have to be set in motion and their inertia comes into play. This must not be confounded with their viscosity.

A solid body differs from a viscous fluid in that a small force produces in it a definite change of shape in a short time, and thereafter no further deformation takes place. Many solids, however, such as lead, tin, copper, and iron, when subjected to very great stresses, behave like viscous fluids, and keep *flowing* as long as the pressure is kept up. Even with very small forces, such apparently solid bodies as sealing wax and cobbler's wax, which fly to pieces when we subject them to a sudden force, such as a blow from a hammer, will gradually yield when sufficient time is allowed, and consequently they must be considered as very viscous fluids. For instance, a leaden bullet will sink in a thick piece of cobbler's wax and a cork will rise upwards through it, just as they would do through syrup or water, but they may take many months or years to do so.

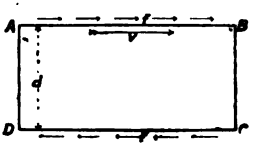

VISCOSITY OF A FLUID.

The viscosity of a fluid is measured by the shear stress required to deform it at the uniform rate of unit shear strain per unit time. Thus, if the figure represents a small portion of fluid and if a tangential stress f acts along A B and C D, the fluid will change its shape by the part A B moving along with a velocity v, relatively to the part D C.

Then, $\left.\begin{array}{c}\textit{Shear strain produced}\\ \textit{in unit time}\end{array}\right\} = \dfrac{\textit{Velocity of A}}{\textit{Distance A D}}$

Or, *Rate of shear* $= \dfrac{v}{d} = \omega.$

$\therefore$ **Coefficient of viscosity** $= \mu = \dfrac{f}{\omega}. \quad . \quad . \quad . \quad . \quad (I)$

When dealing with fluids at rest and in hydraulic machines,

such as presses, cranes, &c., in which the motion of the liquid is comparatively slow, we need not take account of their viscosity; but when considering their flow through pipes and channels it becomes of great importance.

Transmission of Pressure by a Fluid.—Pascal's law, that "fluids transmit pressure equally in all directions," follows at once from our definition of a fluid. Thus, take a vessel filled with a fluid and fitted with several frictionless pistons which all have the same area and are held in place by springs. If we now apply an inward force through the spring to one of the pistons, say V_1, we shall find that each of the other pistons will be pushed outward with the same force. Had the pistons been of different areas we should have found the forces proportional to their areas, showing that the pressure per unit area is the same in all directions.

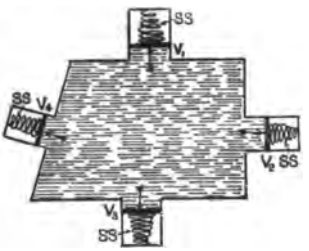

(HORIZONTAL SECTION.)

TRANSMISSION OF PRESSURE BY FLUIDS.

Another property following from our definition is that the pressure on any surface, real or imagined, is everywhere normal to that surface.

Pressure of a Heavy Fluid—Head.—Had the fluid in the above experiment been water or mercury and the pistons placed at different levels, we should have found that the pressure was not the same on all of them, but greatest on the lowest and least on the uppermost piston. This difference is due to the weight of the fluid. For example, if we have a quantity of liquid, the pressure at the bottom end B, of a vertical column A B, would be greater than at A; and, since the pressures round the sides of the column balance one another, the weight and the pressures on the ends must be in equilibrium. The difference of pressure is, therefore, equal to the weight of a cylinder of liquid whose length is A B and whose cross section has unit area. This will obviously be proportional to the length of the column A B; that is, to the difference of level.

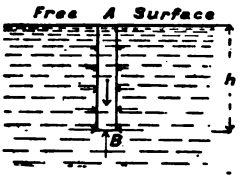

PRESSURE OF A HEAVY FLUID.

In the figure, the upper surface is open to the atmosphere, and is, therefore, called the *Free Surface*. The pressure at A is atmospheric, but in connection with hydraulics it is customary to reckon

this as the zero of reference, and when we speak of the pressure of a fluid we mean the excess of its pressure above that of the atmosphere.

Since we can have any pressure by taking A B of suitable length, we very often measure a pressure by the length of the vertical column of liquid which it will support—or, what is the same thing, which will produce the same pressure—and we shall term this length the *Head.* The column itself we shall refer to as the *Pressure Column.* With water each foot of head, and with mercury each inch, corresponds to nearly half a pound per square inch. The exact figures are :—

1 Foot of Water = 0·434 lb. per square inch.

1 Inch of Mercury = 0·491 ,, ,,

If h be the height of the free surface above the point we are considering, and w the weight of unit volume of the liquid, the pressure per unit area will be :—

$$p = w\,h. \quad . \quad . \quad . \quad . \quad . \quad . \quad . \quad . \quad \text{(II)}$$

For fresh water, w may be taken as 62·42, or nearly 62½ lbs. (1,000 ounces) per cubic foot, or 0·0361 lb. per cubic inch.

Pressure on an Immersed Surface.—If the above pressure be exerted on every unit of a surface whose area is a, the *total pressure* on that surface will be :—

$$P = a \times p = a\,w\,h. \quad . \quad . \quad . \quad . \quad . \quad . \quad \text{(III)}$$

This is also frequently called "the pressure," but it is usually quite clear whether the total pressure or the intensity of pressure is meant, although they are commonly denoted by the same term.

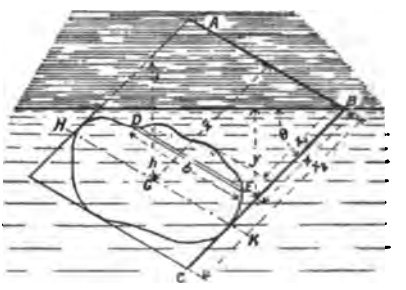

PRESSURE ON A SUBMERGED SURFACE.

On a plane surface which is not level, the intensity of pressure is not the same for all parts. In such a case, we may find the total pressure as follows :—

Let A B be the intersection of the plane of the submerged surface with the free surface of the water. Draw the line B C in that plane perpendicular to A B, and take D E, a very narrow strip or element of the surface, at right angles to B C

and distant x from A B. A B and D E will be parallel since they are in one plane and both perpendicular to B C. Consequently, D E will be horizontal, and, therefore, the intensity of pressure over it will be uniform and equal to $w\,y$, y being the depth of the strip below the surface. Hence, if b be the breadth D E of the surface (*i.e.*, the length of the strip), and $d\,x$ that of the strip, the total pressure on the element will be $b\,d\,x \times w\,y$, or $b\,d\,x\,w\,x \sin\theta$ since $y = x \sin\theta$, if θ be the inclination of the plane to the horizontal. Now, we can split up the whole surface into a very large number of such elements and the total pressure on it will be the sum of all those on the elements :—

$$\therefore \qquad P = w \sin\theta \int_{x_1}^{x_2} b\,x\,d\,x.$$

But $b\,x\,d\,x$ is the area of an element multiplied by its distance from A B, and, therefore, from the definition of the centre of gravity of a lamina, the integral is equal to the whole area a multiplied by the distance of its centre from A B. Let this distance be $\bar{x}$, and let $h = \bar{x} \sin\theta$, be the depth of the centre below the surface :—

Then, $$P = w \sin\theta \times a\,\bar{x} = a\,w\,h. \quad . \quad . \quad . \quad (\mathrm{III}_a)$$

This is evidently the same pressure as if the surface were level and immersed at the same depth as its centre of gravity.

EXAMPLE I.—A cylindrical tank, 6 feet in diameter and 10 feet deep, is filled with water; find the bursting pressure round the base of the tank, and the pressure on its base.

ANSWER.—The bursting pressure round the base is measured by the intensity of the fluid pressure on any small area of the curved surface infinitely near to the base. This pressure will be exactly equal to that on the base. Hence, the question resolves itself into finding the intensity of the pressure on the base.

$\therefore$ **Bursting pressure round the base of tank** = *Pressure per square inch on base.*

" " = $a\,h\,w$.

" " = $\frac{1}{144} \times 10 \times 62{\cdot}5 = 4{\cdot}34$ **lbs. per sq. in.**

Again, **Total pressure on base** = *Area of base in sq. ins.* × *pressure per sq. in.*

Or, " " = $\frac{22}{7} \times 36 \times 36 \times 4{\cdot}34 = 17{,}678$ **lbs.**

EXAMPLE II.—A circular water tank is 20 feet in diameter and 25 feet deep. It is constructed of 6 rings of cast-iron plates. Find the *total* stress on any vertical section of the bottom row of plates made by a plane passing through the axis of the cylinder, neglecting any assistance afforded by the flanges or connection with the bottom plate. (S. and A. Exam., 1888.)

ANSWER.—It has been proved in Lecture XXIX. that when a cylindrical shell is subjected to internal fluid pressure, the *total* stress in the material along any section made by a plane containing the axis of the cylinder is equal to the total fluid pressure on either side of that part of the plane intercepted within the cylinder.

Hence, total stress in material of bottom row of plates = total fluid pressure on vertical plane through the axis of the cylinder at the bottom row of plates.

Since the breadth of each ring $= \frac{25}{6} = 4\frac{1}{6}$ ft.; therefore, depth of *c. g.* of bottom ring $= h = 25 - \frac{1}{2} \times 4\frac{1}{6} = 22{\cdot}9\dot{6}$ ft.

$$\therefore \left.\begin{array}{l}\text{Total stress in material}\\ \quad\text{along section at bottom}\\ \quad\text{row of plates}\end{array}\right\} = a\,h\,w,$$

$$\text{,, ,, } = (20 \times 4\tfrac{1}{6}) \times 22{\cdot}9\dot{6} \times 62{\cdot}5 \text{ lbs.}$$

$$\text{,, ,, } = 119{,}357 \text{ lbs.}$$

EXAMPLE III.—How is the pressure of water on a given area immersed in it ascertained? A water tank, 8 feet long and 8 feet wide, with an inclined base, is 12 feet deep at the front and 6 feet deep at the back, and is filled with water. Find the pressure in lbs. on each of the four sides, and on the base; water weighing $62\frac{1}{2}$ lbs. per cubic foot.

ANSWER.—The total fluid pressure on any area immersed in the fluid is given by the formula—$P = a\,h\,w$.

Where a = Area of surface exposed to the fluid pressure,

h = Depth of centre of gravity of immersed area below free surface of fluid,

w = Weight of a cubic unit of fluid.

The shape and dimensions of the tank will be readily seen from the figure.

(*a*) *To find the total pressure on the front* A B C D.

Here, a = A D × D C = 8 × 12 = 96 sq. ft.

$h = \frac{1}{2}$ depth D C = 6 ft. $w = 62\frac{1}{2}$ lbs. per cubic ft.

$\therefore$ Pressure on front A B C D $= a\,h\,w$,

$$\text{,, ,, } = 96 \times 6 \times 62\tfrac{1}{2} = 36{,}000 \text{ lbs.}$$

(*b*) *To find the total pressure on the back* E F M N.

Here, $a = \text{F M} \times \text{M N} = 8 \times 6 = 48$ sq. ft.; $h = \frac{1}{2}\,\text{E F} = 3$ ft.

∴ **Pressure on back E F M N** $= a\,h\,w$,

" " $= 48 \times 3 \times 62\frac{1}{2} =$ **9,000 lbs.**

(*c*) *To find the total pressure on base* C B M F.

Before we can find the area of the base, we must know its length C F. From F draw F H parallel to E D, and therefore perpendicular to D C. Then C H F is a right-angled triangle

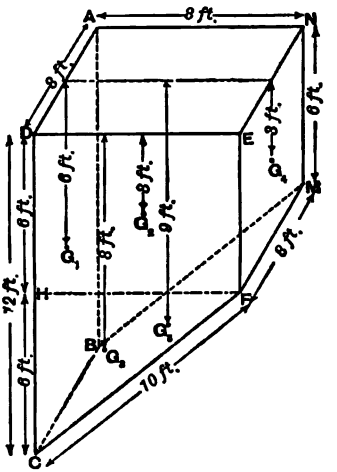

PRESSURE ON SIDES OF TANK.

whose sides are $\text{F H} = \text{E D} = 8$ ft., and $\text{H C} = \text{D C} - \text{D H} = \text{D C} - \text{E F} = 6$ ft.

∴ $\text{C F} = \sqrt{\text{H F}^2 + \text{H C}^2} = \sqrt{8^2 + 6^2} = 10$ ft.

∴ $a = \text{C F} \times \text{C B} = 10 \times 8 = 80$ sq. ft.

Again, the depth of the *c. g.* of the base C B M F is clearly—

$$h = \tfrac{1}{2}(\text{D C} + \text{E F}) = 9 \text{ ft.}$$

∴ **Pressure on base C B M F** $= a\,h\,w$,

" " $= 80 \times 9 \times 62\frac{1}{2} =$ **45,000 lbs.**

(*d*) *To find the total pressure on either side* C D E F or A B M N.

In this case it is perhaps best to divide the trapezoidal area C D E F into two figures whose centres of gravity can be easily determined. Thus, the line F H divides the side C D E F into a rectangle D E F H, and a triangle F H C. Then the total pressure on C D E F is equal to the sum of the pressure on D E F H and F H C.

Area of D E F H $= 8 \times 6 = 48$ sq. ft.

And, *Depth of c. g. of area* D E F H $= \frac{1}{2}$ E F $= 3$ ft.

$\therefore$ *Pressure on* D E F H $= a\,h\,w$

" " $= 48 \times 3 \times 62\frac{1}{2}$ lbs.

Again, *Area of* F H C $= \frac{1}{2}$ H F $\times$ H C $= \frac{1}{2} \times 8 \times 6 = 24$ sq. ft.

The *c. g.* of triangle F H C is at a distance of $\frac{1}{3}$ of H C below the horizontal F H, and therefore at a distance of $6 + \frac{1}{3}$ of 6 or 8 feet below D E.

$\therefore$ *Pressure on* F H C $= a\,h\,w$,

" " $= 24 \times 8 \times 62\frac{1}{2}$ lbs.

$\therefore$ **Pressure on side C D E F or A B M N** $= 48 \times 3 \times 62\frac{1}{2} + 24 \times 8 \times 62\frac{1}{2}$ lbs.,

" " $= 48 \times 62\frac{1}{2} \times (3 + 4) = 21{,}000$ lbs.

EXAMPLE IV.—A cylindrical vessel, 10 feet long, open at one

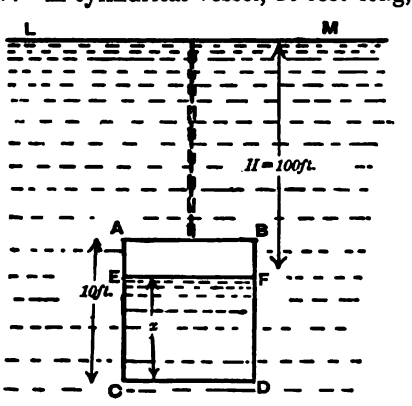

PRESSURE IN DIVING BELL.

end and closed at the other, forms a diving bell. It is lowered

into water with its open end downwards until the surface of the water in the cylinder is at a depth of 100 feet. Find how far the water has risen in the cylinder, and the pressure of the contained air. (Take the height of the water barometer as 34 feet.)

ANSWER.—

Let H = Depth of surface of water in bell = 100 feet.
" h = Height of water barometer = 34 feet.
" l = Length of cylinder forming bell = 10 feet.
" x = Height that water rises in bell.

Before the bell is immersed in the water the pressure of the contained air is simply that due to the atmosphere. After immersion the pressure will be greater than that of the atmosphere by an amount due to a head of water of H feet.

Assuming, then, that the air in the bell has been compressed according to Boyle's Law ($p\,v$ = a const.), we get:—

$$\left.\begin{array}{l}\textit{Press. of compressed air}\\ \times\ \textit{Vol. of compressed air}\end{array}\right\} = \left\{\begin{array}{l}\textit{Press. of atmosphere}\\ \times\ \textit{Vol. of bell.}\end{array}\right.$$

$$\therefore \quad \frac{\textit{Vol. of compressed air}}{\textit{Vol. of bell}} = \frac{\textit{Press. of atmosphere}}{\textit{Press. of compressed air}}.$$

Since the bell is of uniform cross sectional area throughout, we get:—

$$\frac{\textit{Vol. of compressed air}}{\textit{Vol. of bell}} = \frac{l-x}{l}.$$

$$\therefore \quad \frac{l-x}{l} = \frac{h}{\mathrm{H}+h}.$$

$$\therefore \quad x = \frac{\mathrm{H}\,l}{\mathrm{H}+h} = \frac{100 \times 10}{100+34} = 7{\cdot}46 \text{ feet.}$$

The pressure of the air in the bell when immersed is equal to the pressure due to a depth of (H + h) feet of water.

$$\therefore \quad \text{Pressure of air in bell} = a\,(\mathrm{H}+h)\,\mathrm{W} = \frac{1}{144} \times 134 \times 62{\cdot}5$$

$$\text{" \quad " } = 58{\cdot}16 \text{ lbs. per sq. inch.}$$

Centre of Pressure.—We could balance the pressure on an immersed surface by a single force—the reverse of the resultant of the pressure—acting through a certain point in the plane of the surface, and this point is called the *Centre of Pressure.*

To find the depth of the centre of pressure we may proceed as follows :—

Referring to our former figure we see that the moment about A B of the pressure on the elementary strip D E is $w\,y \times b\,d\,x \times x$, or $w \sin \theta\, b\, x^2\, d\,x$. Hence the total moment is:—

$$M = w \sin \theta \int_{x_1}^{x_2} b\, x^2\, d\,x.$$

Now, $b\,x^2\,d\,x$ is the product of the area of an element into the square of its distance from A B, and consequently $\int_{x_1}^{x_2} b\,x^2\,d\,x$ is the second moment, or moment of inertia, of the area about A B. As shown in equation (III) of Lecture XXII., it is, therefore, equal to $I + a\,\bar{x}^2$, where I is the moment of inertia about an axis H K, through the centre of gravity parallel to A B :—

$$\therefore \qquad M = w \sin \theta\,(I + a\,\bar{x}^2).$$

Again, the moment of the resultant must be the sum of the moments of its components. Let X be the distance of the centre of pressure from A B :—

Then, $$P\,X = M = w \sin \theta\,(I + a\,\bar{x}^2).$$

$$\therefore \qquad X = \frac{w \sin \theta\,(I + a\,\bar{x}^2)}{P} = \frac{w \sin \theta\,(I + a\,\bar{x}^2)}{w \sin \theta\, a\,\bar{x}}.$$

$$\therefore \qquad X = \frac{I + a\,\bar{x}^2}{a\,\bar{x}}. \quad . \quad . \quad . \quad . \quad . \quad . \quad . \quad . \quad . \quad (IV)$$

That is, the distance of the centre of pressure from A B is the ratio of the second moment of the surface about A B to its first moment about the same axis.

If for I we write $a\,k^2$, k being the radius of gyration about the axis H K, and h for $\bar{x} \sin \theta$, we get :—

$$X = \frac{a\,k^2 + a\,\bar{x}^2}{a\,\bar{x}} = \frac{k^2 + \bar{x}^2}{\bar{x}} = \frac{k^2 \sin^2 \theta + h^2}{h \sin \theta}. \quad . \quad . \quad (V)$$

We shall now show how to apply these results to a few simple cases, and will also explain an easier method for special cases.

Centre of Pressure on a Rectangle.—First, consider a rectangle immersed with one edge in the surface. We find from Table II. in Lecture XXII., that the value of k^2 for a rectangle is $\frac{1}{12}\,l^2$,

where l is the length of the rectangle at right angles to the axis. Also, $\bar{x}$ will be $\frac{1}{2} l$:—

$$\therefore \qquad X = \frac{\frac{1}{12} l^2 + \frac{1}{4} l^2}{\frac{1}{2} l} = (\tfrac{1}{6} + \tfrac{1}{2}) l = \tfrac{2}{3} l. \quad . \quad . \quad . \quad \text{(VI)}$$

If the rectangle be immersed further, until its centre is at a depth h, the top edge being kept horizontal, we do not get such a simple result, but it can be at once obtained for any given case from equation (V).

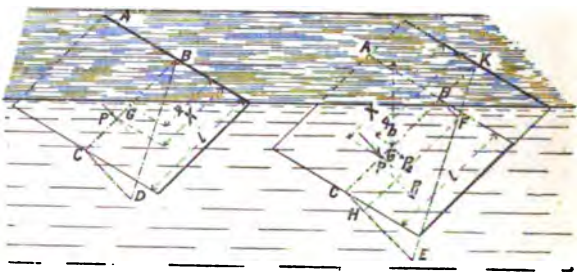

CENTRE OF PRESSURE ON A RECTANGLE.

We can also obtain our result in the following manner:—At every point in B C—the central line of the rectangle—draw a line at right angles to it of such a length as to represent the whole pressure on a horizontal strip at that level. When the ends of these are joined we will have a triangle B C D, whose area represents the total pressure on the rectangle. The resultant pressure will pass through the centre of gravity of this triangle, and will, therefore, be two-thirds down from the vertex. Hence, the centre of pressure is distant two-thirds of the length of the rectangle from the top.

When the upper edge of the rectangle is below the surface, we obtain, instead of a triangle to represent the pressure, a trapezium B F E C, whose inclined sides, when produced, meet in the surface of the liquid. We ascertain the centre of pressure by finding the resultant of two forces, P_1 and P_2, the former of which is proportional to the area of the triangle F E H, and is two-thirds down from F, while the latter passes through the centre of the rectangle B F H C, and is proportional to its area. This may be done graphically as explained in Lecture XXVIII.

Centre of Pressure on a Triangle.—For a triangle with its base in the surface, $k^2 = \frac{1}{18} l^2$, and $\bar{x} = \frac{1}{3} l$:—

$$\therefore \qquad X = \frac{\frac{1}{18} l^2 + \frac{1}{9} l^2}{\frac{1}{3} l} = (\tfrac{1}{6} + \tfrac{1}{3}) l = \tfrac{1}{2} l. \quad . \quad . \quad \text{(VII)}$$

This may also be proved geometrically. The intensity of pressure on a horizontal strip is proportional to its depth below the surface, while the length of the strip, and, therefore, its area, is proportional to its distance from the vertex C. Consequently, the whole pressure on each horizontal element will be proportional to the product $x\ (l - x)$ for elements of the same width. The area representing the pressure will, therefore, be a parabola, B E D C, passing through B and C, with its axis perpendicular to B C, and, consequently, the centre of pressure must be half way down.

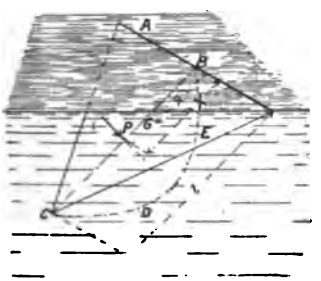

CENTRE OF PRESSURE ON A TRIANGLE.

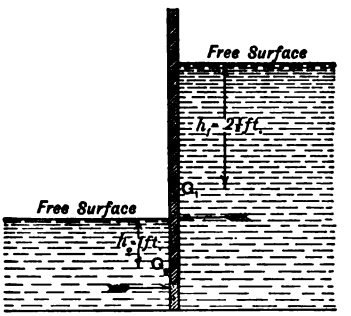

PRESSURE ON SLUICE GATE.

If the vertex is in the surface, and the base horizontal, then $\bar{x} = \frac{2}{3} l$:—

$$\therefore \qquad X = \frac{\frac{1}{18} l^2 + \frac{4}{9} l^2}{\frac{2}{3} l} = \left(\tfrac{1}{12} + \tfrac{2}{3}\right) l = \tfrac{3}{4} l. \quad . \quad . \quad \text{(VIII)}$$

Centre of Pressure on a Circle.—The only other case we shall consider is that of a circle immersed vertically, with its centre at a depth h. Here $k^2 = \frac{1}{4} r^2$, and $\bar{x} = h$:—

$$\therefore \qquad X = \frac{\frac{1}{4} r^2 + h^2}{h}. \quad . \quad . \quad . \quad . \quad . \quad . \quad . \quad \text{(IX)}$$

When the circumference just touches the surface, $h = r$, and this becomes :—

$$X = \tfrac{5}{4} r = \tfrac{5}{8} d. \quad . \quad . \quad . \quad . \quad . \quad . \quad . \quad . \quad \text{(X)}$$

Where r is the radius, and d the diameter of the circle.

EXAMPLE V.—A sluice gate is 4 feet broad and 6 feet deep, and the water rises to a height of 5 feet on one side, and 2 feet on the other side. Find the pressure on the gate, and the centres of pressure.

ANSWER.—The net pressure on the sluice gate is evidently equal to the difference of the pressures on the two sides.

Total Pressure on Back $= a_1 h_1 w = (4 \times 5) \times 2{\cdot}5 \times 62{\cdot}5 = 3{,}125$ lbs.

" " *Front* $= a_2 h_2 w = (4 \times 2) \times \ 1 \times 62{\cdot}5 = \ 500$ "

$\therefore$ Net pressure on gate = 2,625 "

The centre of pressure on the upper side is one-third of 5 feet, or 1 foot 8 inches, up from the bottom, and on the lower side, a third of 2 feet, or 8 inches. To find the resultant centre of pressure take moments about the bottom of the gate. Then, if this centre be distant x inches from the bottom :—

$$2{,}625 \times x = 3{,}125 \times 20 - 500 \times 8 = 62{,}500 - 4{,}000.$$

$$\therefore \quad x = \frac{58{,}500}{2{,}625} = 22{\cdot}3 \text{ ins.} = 1 \text{ ft. } 10{\cdot}3 \text{ ins.}$$

Energy of Still Water.—When water is at rest it possesses potential energy in virtue of its position and of its pressure. Consider a tank filled with water, and imagine a small mass m of the water to escape from the tank. This mass will not only lose potential energy through falling to a lower level, but it could also do work because of the pressure of the rest of the water pushing it away. It is convenient to assume some datum level at which we take the energy of position as zero.

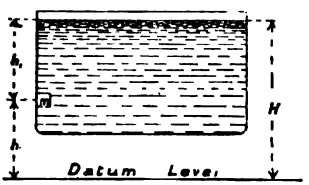

ENERGY OF STILL WATER.

Let H = Height of free surface above the datum level.
" h_1 = Height of free surface above m.
" h_2 = Height of m above datum level.
" g = Acceleration due to gravity.
" ρ = Density of fluid = mass of unit volume.
And, w = Weight of unit volume of fluid = ρg.

Then the work done in forcing out the mass m is :—

Energy of Pressure = *Volume* × *Pressure.*

$$\text{" \quad "} \quad = \frac{m}{\rho} \times w h_1 = m g h_1.$$

And, *Energy of Position* $= m g h_2$.

$\therefore$ *Total Energy* $= m g (h_1 + h_2) = m g$ H.

Or, for a unit mass :—

$$\text{Energy per unit mass} = g (h_1 + h_2) = g \text{ H}. \quad . \quad \text{(XI)}$$

This is constant for all parts of a homogeneous fluid at rest, and H may be called the *total head* of the water in the tank.

Common Suction Pump.—This consists of a bored cast-iron barrel P B, terminating in a suction pipe, S P, fitted with a perforated end or rose R, which dips into the well from which the water is to be drawn. The object of the rose is to prevent leaves or other matter getting into the pump, that might clog and spoil the action of the valves. At the junction between the barrel and suction pipe there is fitted a suction valve S V, of the hinged clack type faced with leather. The piston or bucket B is worked up and down in the barrel of the pump by a force P, applied to the end of the handle H. This force is communicated to it through the connecting link of the hinged piston-rod, P R. In the centre and at the top of the bucket is fixed the clack delivery valve D V, which is also faced with leather in order to make it water-tight. The bucket is sometimes packed with leather; but, in the present instance, a coil of tightly woven flax rope is wrapped round the packing groove.

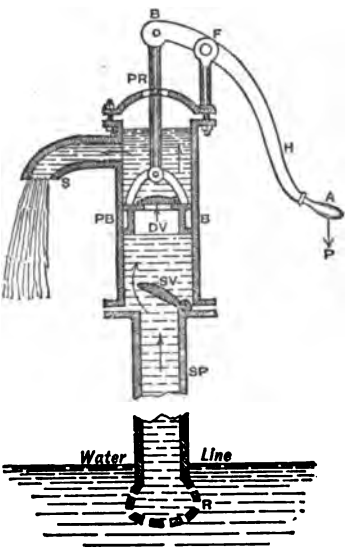

COMMON SUCTION PUMP.

Action of the Suction Pump.—(1) Let the barrel and the suction pipe be filled with air down to the water-line, and let the bucket be at the end of the down stroke. Now raise the bucket to the end of the up stroke by depressing the pump handle. This tends to create a vacuum below the delivery valve; therefore, the air which filled the suction pipe opens the suction valve, expands, and fills the whole volume of the barrel. Consequently, according to Boyle's law, its pressure must be diminished in the *inverse ratio* to the enlargement of its volume. This enables the pressure of the atmosphere to force a certain quantity of water up the suction pipe, until the weight of this column of water and the pressure of the air between the suction and delivery valve, balance the pressure of the outside atmosphere.

(2) In pressing the bucket to the bottom of the barrel by ele-

vating the handle, the suction valve closes and the delivery valve opens, thereby permitting the compressed air in the barrel to escape through the delivery valve into the atmosphere.

(3) Raise and depress the piston several times so as to produce the above actions over again, and thus gradually diminish the volume of the air in the pump to a minimum. Then water will have been forced by the pressure of the atmosphere up the suction pipe and into the pump, if the bucket and the valves are tight, and if the delivery valve when at the top of its stroke be not more than the height of the hydro-barometric column above the water line of the well.*

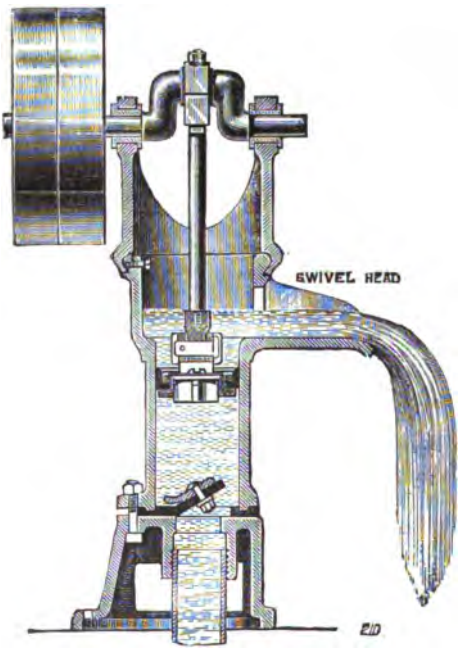

BELT-DRIVEN SUCTION PUMP.

(4) The bucket now works in water instead of in air; in fact, the machine passes from being an air-pump to being a water one. During the down stroke of the piston water is forced through the delivery valve, and during its up stroke, this water is ejected through the spout; at the same time, more water is forced up through the suction pipe and valve to fill the vacuum created by the receding piston. In the case of a common suction pump water is therefore discharged *only* during the up stroke of its piston.

* Theoretically, such a pump should be able to lift water from a depth of 34 feet below the highest part of the stroke of the delivery valve, but practically, owing to the imperfectly air-tight fitting of the piston and the valves, it is not used for withdrawing water from wells more than 20 to 25 feet below this position of the delivery valve. In fact such a pump frequently requires a bucket or two of water to be poured into it above the delivery valve in order to make it work at all, if it should have been left standing for some time without being worked.

Belt-driven Suction Pump.—When we have to raise a considerable quantity of water during a long time, then it becomes advisable to apply power derived from some prime mover. The foregoing figure illustrates an ordinary suction pump driven by a belt, with fast and loose pulleys, crank shaft, and connecting-rod. Here the suction valve and the piston are faced with leather or india-rubber, whilst the bucket valve is made of brass and ground to fit its seat. The upper portion of the pump is fitted with a swivel head, so that the pulleys may be placed fair in line with the driving pulleys.

LEATHER PACKING FOR PISTON OF SUCTION PUMP.

EXAMPLE VI.—Given two simple bucket pumps, each having a stroke of 1 foot, and cross area of bucket, 20 square inches. Suppose everything perfectly air tight, and the supply pipe 20 square inches area in one case, and 10 square inches area in the other. Neglecting friction, you are to compare the tensions on the pump rods at ends of first up stroke in each case, supposing the bucket to be 24 feet above free surface of the water in the well when at the bottom of its stroke. The supply pipe reaches to the under surface of bucket when the latter is at the bottom of its stroke.

ANSWER.—

Let p = Pressure in lbs. per *sq. ft.* on *under* surface of bucket at end of first up stroke.

,, a = Area of bucket $= \frac{20}{144}$ sq. ft.

,, h = Height of water barometer = 34 ft.

,, w = Weight of 1 cub. ft. of water = $62\frac{1}{2}$ lbs.

,, x = Height water rises in suction pipe for first up stroke.

FIRST CASE.—*Lifting or suction pipe having an area equal to that of the bucket.*

Then at end of first up stroke, we get :—

Pressure of air on upper surface of bucket, ... = *Atmospheric Pressure*

,, ,, $= a\,h\,w$ *lbs.* . . . . (1)

Pressure on under surface of bucket, $= p\ a = \left\{ \begin{array}{l} \textit{Atmos. pressure} \\ \textit{-pressure of} \\ \textit{small column, } x, \\ \textit{of water} \end{array} \right.$

,, ,, $= a\,(h - x)\,w.$

And, $p = (h - x)\,w.$ . . . . (2)

Since there is exactly the same quantity of air between the bucket and the surface of the water in the pipe at the end of the stroke as there was before the stroke commenced, we may apply Boyle's Law to determine the *volume* of air under the bucket at end of stroke.

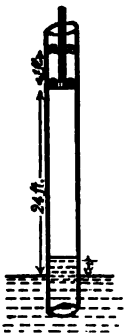

FIRST CASE.

$$\therefore \qquad p\,a \times (25 - x) = a\,h\,w \times 24.$$

Substituting, $p = (h - x)\,w$, from equation (2), we get:—

$$(h - x)\,(25 - x) = 24\,h.$$

Since, $h = 34$ ft., we get, by substitution, and multiplication:—

$$x^2 - 59\,x + 34 = 0.$$

$$\therefore \qquad x = \frac{59 \pm 57{\cdot}83}{2} \text{ ft.}$$

The minus sign in the numerator of the fraction on the right-hand side of this equation is the only one admissible.

$$\therefore \qquad x = \frac{1{\cdot}17}{2} = {\cdot}58 \text{ ft. } or = 7 \text{ inches, nearly.}$$

Hence,

$$\text{Tension in pump rod} = \left\{ \begin{array}{l} \textit{Press. on upper surface of bucket} \\ \quad - \textit{Press. on under surface.} \end{array} \right.$$

$$\text{,, \quad ,,} \quad = a\,h\,w - a\,(h - x)w = a\,x\,w.$$

$$\text{,, \quad ,,} \quad = \frac{20}{144} \times {\cdot}58 \times 62{\cdot}5 = 5{\cdot}04 \text{ lbs.}$$

SECOND CASE.—*Lifting or suction pipe having an area equal to half that of the bucket.*

The symbols denoting the same quantities as before, we get:—

Pressure of air on upper surface of bucket $= a\,h\,w$ lbs. . . (3)

Pressure on under surface of bucket $= p\,a$

,, ,, $= a\,(h - x)\,w$. . . (4)

Vol. of air between bucket and surface of water at beginning of stroke . . $= \frac{1}{2}\,a \times 24$

,, ,, $= 12\,a$ *cub. ft.*

Vol. of air between bucket and surface of water at end of up stroke . . . $= \frac{1}{2}\,a \times (24 - x) + a \times 1$

,, ,, $= \frac{1}{2}\,(26 - x)\,a$ *cub. ft.*

∴ By Boyle's Law, we get :—

$$(h - x)w \times \tfrac{1}{2}(26 - x)a = hw \times 12a.$$

Substituting $h = 34$, and simplifying, we get:—

$$x^2 - 60x + 68 = 0$$

$$\therefore \qquad x = 1{\cdot}15 \text{ ft. } or = 13{\cdot}8 \text{ inches, nearly.}$$

Hence,

Tension in pump rod $= a\,x\,w.$

$$\text{,, } \qquad \text{,, } \qquad = \frac{20}{144} \times 1{\cdot}15 \times 62{\cdot}5 = 10 \text{ lbs.}$$

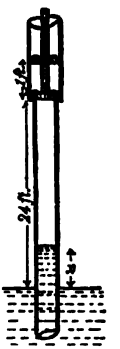

SECOND CASE.

Air Pump.—The figure on next page is a sectional elevation and outside plan of the air pump for the 1500 horse-power compound engines of the S.S. "St. Rognvald," which are fully described in the Author's *Text-Book on Steam and Steam Engines.* During the up stroke of the pump bucket P B, condensed steam and vapour are drawn from the surface condenser through the foot valve F V, into the space below the bucket, whilst any water and vapour that may have been lying above it, are forced through the delivery valves D V, into the hot well H. During the down stroke of the bucket, the water and vapour below it pass upwards through the bucket valves B V, into the space left by the descending bucket; at the same time, the foot and delivery valves automatically close on their seats. These actions take place in succession during each up and down stroke of the air pump-rod A P R, which passes through an air-tight stuffing box, and is linked to the piston-rod crosshead of the high-pressure cylinder by short connecting-rods and side levers.

The object of placing the delivery valves on the top of the air-pump barrel in addition to the ordinary bucket valves, is to cause a vacuum to be produced above the latter during the down stroke of the bucket, and thus facilitate their opening, as well as to give the vapour from the condenser a free space between these two sets of valves into which it can expand.

The cast-iron barrel of the air pump is lined with a truly bored brass chamber B Ch, the pump bucket is rendered tight by hemp rope packing H P, the foot valve is readily inspected or removed by unbolting or lifting the foot valve cover F V C, whilst the whole is bolted securely to the surface condenser bracket S C_1 B, and to the circulating pump bracket C P_1 B.

Single-acting Force Pump.—The upper or outer end of the pump barrel P B, is provided with a stuffing-box S B, and gland G, through the air-tight packing of which the solid pump plunger P P, works. During the up or outward stroke of the plunger a vacuum is created in the pump barrel, and consequently air is expanded into it from the suction pipe. This pipe is attached to the flange of the suction valve-box. During the down or inward stroke the suction valve S V, closes, and the pent-up air in the barrel is forced through the delivery valve D V. This

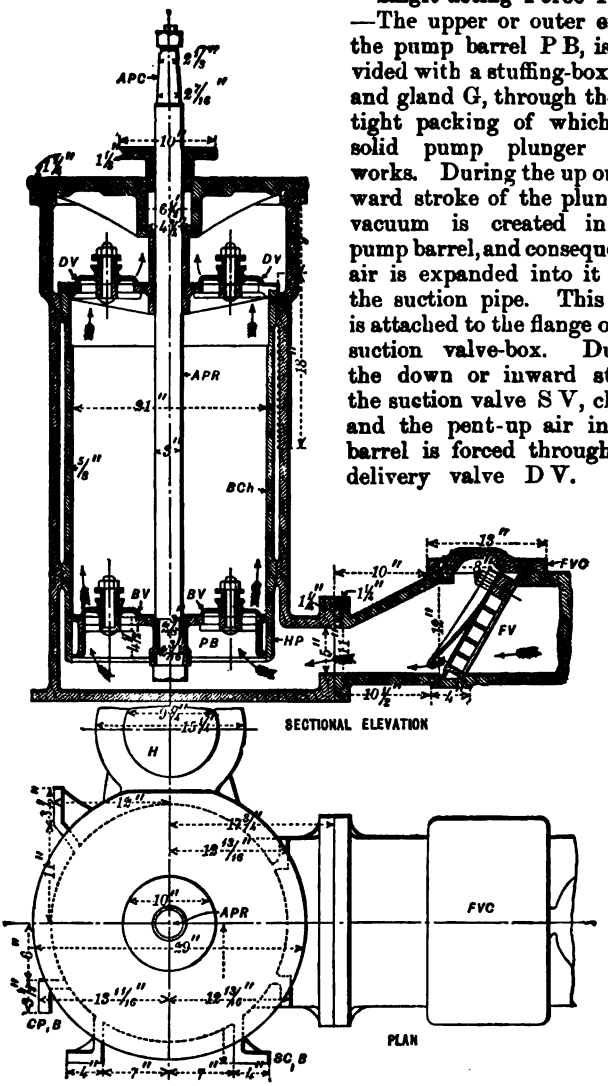

AIR PUMP FOR A MARINE ENGINE.

action goes on precisely in the manner just explained in the case of the suction pump, until the water rises into the barrel. Then the inward stroke of the plunger drives through the delivery valve to any desired height or against any reasonable back pressure, as in the case of a feed pump for a steam boiler.

Both the suction and the delivery valves are made of brass, and fit accurately into their brass seats. The covers to the valve chests are provided with checks Ch, to prevent the valves from rising more than the distance required to pass the water freely through them.*

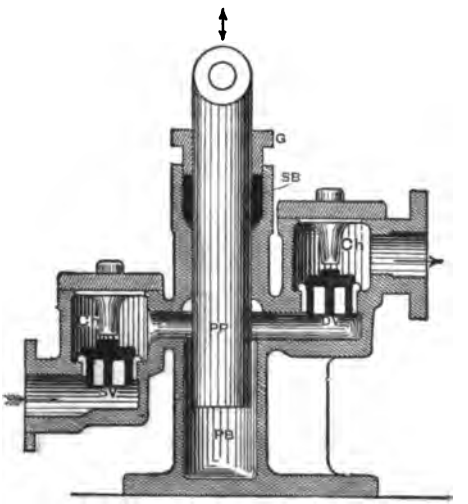

SINGLE-ACTING FORCE PUMP.

The eye of the plunger may be attached to a connecting-rod actuated by a hand lever, as in the case of the common suction pump, or it may be worked from an eccentric or crank revolved by a steam engine or other motor. By whichever way it is worked, the force applied to the plunger must be sufficient to overcome the friction between the plunger and the packing, the resistance due to sucking the water from the source of supply, and of driving the same up to the place where it is delivered.

As in the case of the suction pump, the water is only delivered during each alternate stroke of the plunger, and, consequently, in an intermittent or pulsating fashion.

Very often three pumps of this kind are combined in one, each plunger being driven by a separate crank on a common shaft, and the cranks making angles of 120° with each other. Such an

* If d be the diameter of the bore of the valve seat, and h the required lift of the valve to give an opening equal in area to that bore, then h must be quarter of d. For the area of bore $= \frac{\pi d^2}{4}$ and the equivalent area of the valve opening $= \pi d h$. $\therefore \frac{\pi d^2}{4} = \pi d h$. Or, $h = \frac{d}{4}$.

arrangement is called a *three-throw pump*, and gives a very steady stream.

Single-acting Force Pump with Ball Valves.—The following illustration is a simple modification of the previous one, wherein ball valves are substituted for the common-circular three feathered type. The right-hand side forms the suction and the left-hand the delivery side. All the parts are made extra thick and strong



SINGLE-ACTING FORCE PUMP WITH BALL VALVES.

to resist shocks and vibrations, and most of the bolt holes have been cored to the outside of the flanges for the purpose of facilitating rapid connection and disconnection. This form of pump is much used for forcing feed-water into steam boilers, &c.

Force Pump with Air Vessel.—In the accompanying figure we

have an illustration of a force pump with both the suction and the delivery valves placed on one side of the pump barrel and then surmounted by an air vessel. The plunger, instead of being solid, as in the previous cases, is made up of a hollow trunk or barrel, with a connecting-rod fixed to an eye-bolt at its lower end.

Action of the Air Vessel.—During the inward or delivery stroke of the plunger barrel P B, part of the water, which is forced from the barrel B, goes up through the delivery valve D V, into the delivery pipe D P, and the remainder enters the air vessel A V, and consequently compresses the air therein. During the outward or non-delivery stroke of the plunger the compressed air in the air vessel presses the rest of the water into the delivery pipe. In this simple way a continuous flow of water is maintained in the delivery pipe, and with far less shock, jar, and noise than in the previous cases. Where very smooth working is required, an air vessel is also put on to the suction pipe S P. Should the air in the air vessel become entirely absorbed by the water, the fact will be noticed at once, by the noise and the intermittent delivery. Then, the pump should be stopped, the air cock A C opened, and the water run out. When the air vessel is again full of air, the air cock should be shut and the pump restarted.

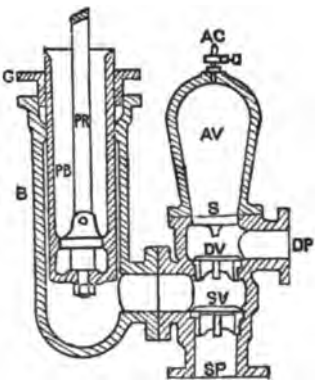

FORCE PUMP WITH AIR VESSEL.

Continuous-delivery Pumps without Air Vessels.—A fairly continuous delivery of water may be obtained by making the plunger of the piston form, and the pump-rod exactly half its area; for here, during the down stroke, half the water expelled by the piston P, from the under side of the pump barrel goes up the delivery pipe D P, and the other half is lodged above the piston, to be in turn sent up the delivery pipe during the up stroke. Where very high pressures are required, such as in the filling of an accumulator ram, pumps working on this principle, but of the following form, are frequently used. The action is precisely the same as in the one just described, and the same index letters have been used, so that the student will have no difficulty in understanding the figure. The directions of motion of the piston and of the ingoing and outflowing water have been marked by straight and feathered arrows respectively.

With accumulators, and for other kinds of high-pressure work, it is not advisable to use air vessels, because you cannot prevent the water which enters them absorbing air and carrying the same with it to the hydraulic machines where its presence would be most objectionable. If 750 to 1000 or more lbs. pressure per square inch be generated, then you would require a very large and strong air vessel before it could be of any service. If a pressure of only 750 lbs. per square inch were used, then, since the normal pressure of the atmosphere is 15 lbs. per square inch, the air in the air vessel would be compressed, in accordance with Boyle's law, to $\frac{15}{750}$, or $\frac{1}{50}$ of its original volume. Consequently, with an air vessel of 50 cubic feet internal capacity, there would be only 1 cubic foot of air in it, when the pump was in full action.

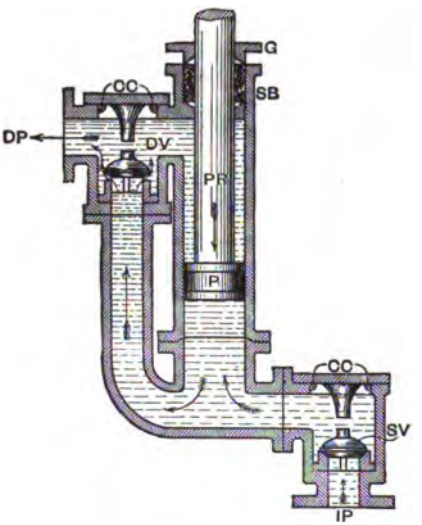

CONTINUOUS-DELIVERY FORCE PUMP WITHOUT AN AIR VESSEL.

Double-acting Force Pump.—The pumps which we have hitherto considered are all single-acting, in the

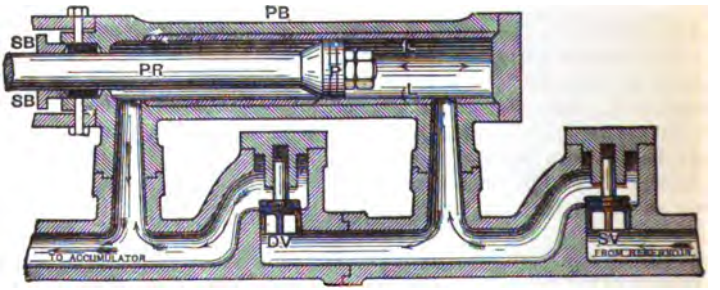

CONTINUOUS-DELIVERY FORCE PUMP AS USED IN CONNECTION WITH THE ARMSTRONG ACCUMULATOR.

sense that they do not both suck and discharge water during

each stroke. This can, however, be accomplished by having two sets of suction and delivery valves placed at each end of the pump barrel, as shown by the accompanying figure. Here, during the outward stroke of the piston the pump draws water from the source of supply through the inlet pipe and suction valve S V_1, while, at the same time, the piston forces water in front of it through the delivery valve D V_2, and outlet pipe. During the inward stroke, suction takes place through S V_2 and discharge through D V_1, all as clearly shown by arrows in the drawing.

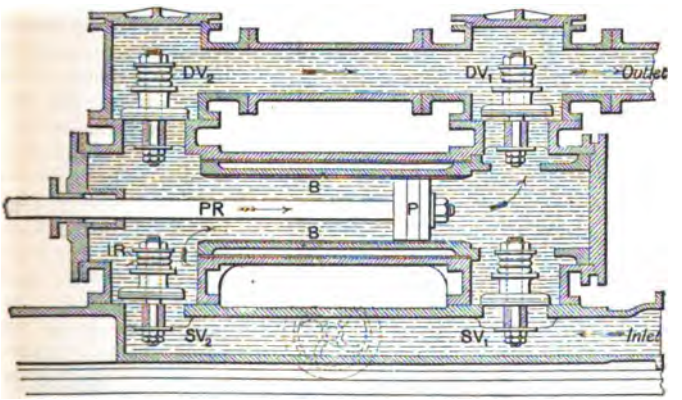

DOUBLE-ACTING FORCE PUMP.

The valves are provided with india-rubber cushions I R, to ease the shock and minimise the jarring noise due to their reaction and natural reverberation when they are suddenly opened and closed.

Double-acting Circulating Pump.—The following figure is a sectional elevation and plan of the circulating pump for the same marine engines as the previously described air pump. During the upstroke of the piston or pump bucket P B, water is drawn from the sea through the suction pipe S P, and the lower suction valves S V, into the lower part of the pump chamber P Ch. At the same time, the water from the top part of the chamber is forced up through the upper delivery valves D V, along the circulating water pipe C W P, into the surface condenser tubes, and from thence into the sea. During the down-stroke of the piston, the water which had previously entered by the bottom of the pump chamber is forced through the lower delivery valves D V, into the condenser tubes and sea, and at the same time, more water is taken into the

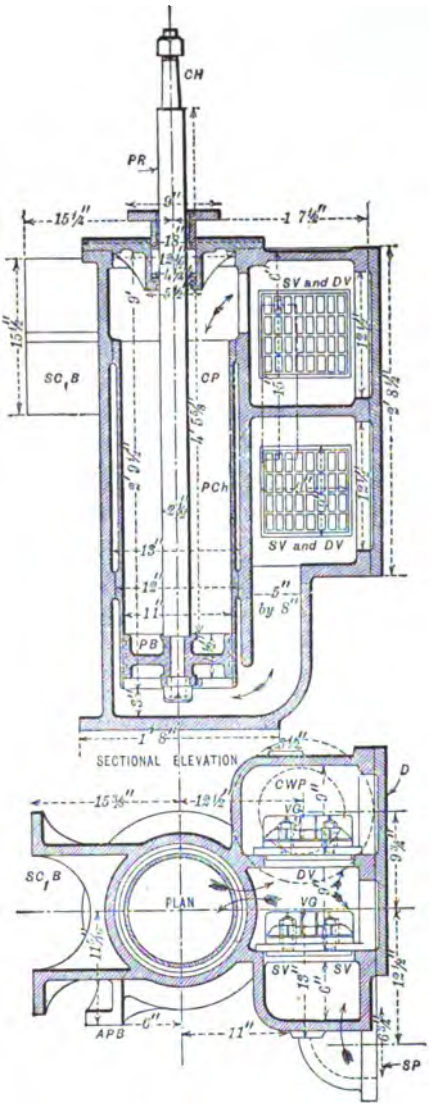

DOUBLE-ACTING CIRCULATING PUMP FOR A MARINE ENGINE.

top part of the pump chamber from the sea through the upper suction valves S V. These double actions take place in the manner described during each stroke, so that a stream of cold water is kept flowing through the condenser tubes, in order to maintain a vacuum during the exhaust of the steam from the low-pressure cylinder on to the outside of the cooled condenser tubes.

The cast-iron pump barrel of the circulating pump is lined with a truly bored brass pump chamber. The pump piston is also made of brass, and is rendered sufficiently water-tight by the simple device of turning three grooves in its outer cylindrical surface. The pump-rod passes through a water-tight gland and stuffing-box, and is connected to the reciprocating piston-rod cross-head by links and side levers, in the same way as the air pump-rod. The whole is securely bolted to the surface condenser and air pump brackets.

Worthington Steam Pump.—The perspective and sectional views

of this well-known pump, together with the following description, will serve to explain the construction and action of one of the best examples of the duplex class of steam pumps for feeding boilers, working accumulators, and hoists. It is termed a duplex pump, from the fact that it consists of two steam and two water cylinders placed side by side. The pumps draw water from the suction pipe S P, and are in this case safeguarded from shock on the suction side by an air vessel S A V. The water is admitted through the suction valves $S V_1$, $S V_2$, at each stroke respectively, and delivered by the valves $D V_1$, $D V_2$, into the discharge pipe D P, under the smoothing action of the discharge air vessel D A V.

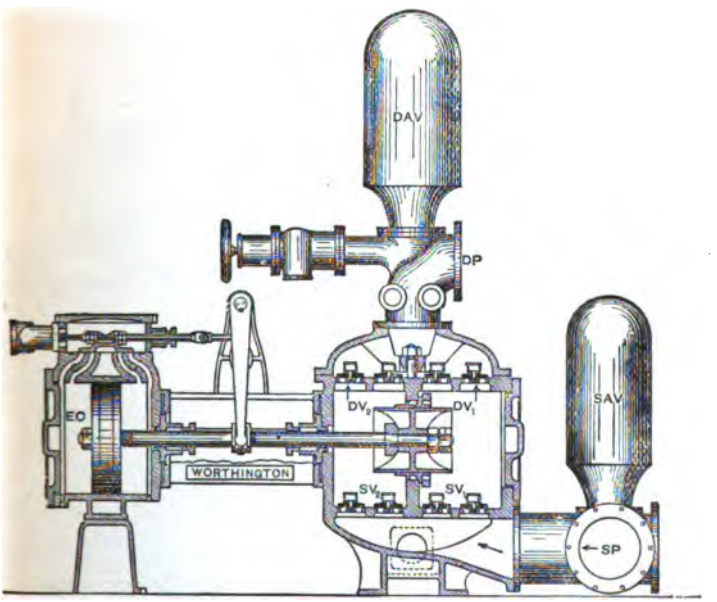

VERTICAL SECTION OF THE WORTHINGTON STEAM PUMP.

The steam pistons and the pump plungers are directly connected together by a piston-rod, and give a swinging motion to the intermediate long levers L, which are attached by two separate spindles to two shorter levers which work the slide valve spindles. Whenever one of the steam pistons moves towards either end of its stroke the other piston is approaching the opposite end of its stroke, and by the combination of levers, piston-rods, and spindles the slide

valve of the one steam cylinder is actuated by its neighbour. The slide valves have neither lap nor lead, but immediately the piston of one cylinder covers one or other of the inner exhaust ports the steam in that cylinder is cushioned, and thus the pistons are prevented from striking their cylinder covers. Each piston as it reaches the end of its stroke automatically waits for its slide valve



PERSPECTIVE VIEW OF THE WORTHINGTON STEAM PUMP.

to be moved by the other piston-rod before it makes a return stroke. By this arrangement, the pump valves have time to close properly on their seats, and a natural smooth motion of the whole of the working parts takes place. There are no dead points in this form of duplex pump, consequently it is always ready to be started either

by the opening of the stop valve or by the automatic action of a float connected to the throttle valve by a chain or rope.

Pulsometer Pumps.—The very first steam pump, which was invented by Thomas Savery in 1698, had no working parts except the valves. This type has been revived for certain kinds of work in pumps of the pulsometer class, of which Bailey's "Aqua Thruster" is a good example. It consists of two long chambers, in each of which there is a valve opening upwards at the bottom, and one opening outwards at the side. At the top junction between these two chambers there is a flap valve which can put either in communication with a steam pipe while the other is shut off therefrom.

Now, suppose the right-hand chamber to be full of water while the left one is full of steam, and that the upper valve is in the position shown. Steam will enter the right-hand chamber and force the water out through the delivery valve at the side. At the same time the steam in the left compartment will be condensing, and water will therefore rise into it through the bottom valve, provided the apparatus be not too far above the free surface of the water. The inertia of this water will cause it to continue in motion after all the steam is condensed, and it will therefore compress the air that remains to a sufficient extent to shift over the valve to the other side.* If there is no air, then the water itself will strike the valve and knock it over to the other side. The conditions of the chambers are now interchanged. Water will be forced out from the left one, and fresh water will rise into the other, and the process begins again.

A large loss occurs in this kind of pump through the condensation of steam during the down stroke of the water, and also owing to the fact that the steam is used non-expansively. To reduce the former loss little cocks open into the top of the chambers and admit a little air during the time there is a vacuum inside. This air prevents the steam from coming so quickly into contact with the water as it otherwise would do, and thus reduces the loss during admission. A slight escape of steam takes place

* This is not the common explanation of the working of the pulsometer valve. It is—"As soon as the water is lowered below the upper surface of the delivery valve, steam blows through with some violence and causes a commotion and a rapid condensation in the chamber. The valve is then *drawn* to the right-hand side." This is quite wrong. The valve can only be shifted by being *pushed*, owing to the pressure on the closed side becoming greater than that on the other side, and it is difficult to see how the pressure in a chamber in direct communication with the boiler can become less than that in one where the steam is already all condensed, and where the pressure is considerably below that of the atmosphere. Besides, it is probable that in steady working the water never gets as low as the delivery valves.



PULSOMETER PUMP BY W. H. BAILEY & CO., LTD., MANCHESTER.



THE "AQUA THRUSTER" IN OPERATION.

through these cocks, as they are always kept open; but as their bore is so very small, the loss is less than the gain. To diminish the latter loss an extra self-acting valve, called the "grel," has been added to some forms of pulsometer with the intention of cutting off the steam earlier, and then using it expansively.

Pumps of this class are exceedingly handy for dealing with dirty water and for temporary purposes owing to their simplicity, few working parts, and the ease with which they can be erected. It is sufficient to suspend them by a chain and connect them by a pipe to a portable boiler. A suction pipe projects down below the water surface, and a flexible hose pipe will carry off the discharged water. The full page illustration shows the "Aqua Thruster" in use for pumping water from a dock during its construction.

Roots' Blower.—A form of rotary pressure pump, known as Roots' Blower, is used for obtaining a blast of air at a moderate

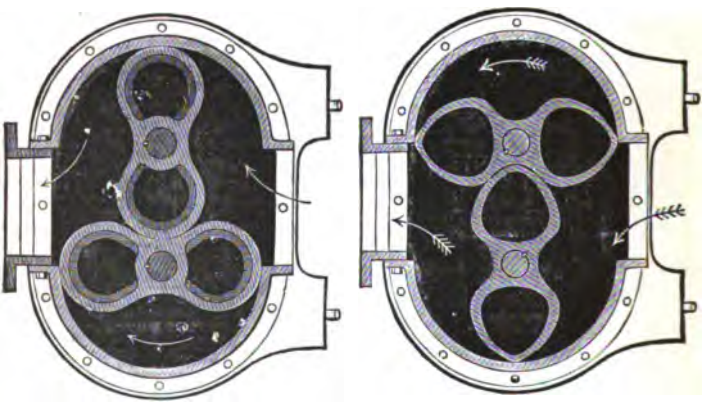

Two Forms of Roots' Blower.

pressure, and for pumping liquids. Two vanes rotate inside a closed casing, and sweep the fluid round with them. They are connected by spur wheels outside so as to be always at right angles to each other, and they have such a shape that practically nothing is carried backwards at the central part of the machine. They can produce a higher pressure than an ordinary blowing fan, and are handier for many purposes than a blower of the cylinder and piston type. The student should note that this is not a centrifugal pump or fan, although there are no reciprocating parts, but simply a rotary form of pressure pump.

If a fluid be forced through this machine, then it will cause the vanes or teeth to rotate; hence it will work as a motor, and there-

fore it is a reversible machine. Many ingenious attempts have been made to produce economical steam engines on this principle; but largely owing to the difficulty of keeping them tight, they have not been so successful as their sanguine inventors expected.*

Bramah's Hydraulic Press.—This useful machine was invented by Pascal, but he could not make the moving parts water-tight. Bramah, about the year 1796, discovered a means by which this difficulty was effectually overcome; and thus the instrument has been handed down to us under his name. As may be seen from the following figure, it consists of a single-acting force pump in connection with a strong cylinder containing a plunger or ram, which is forced outwards from the cylinder through a tight collar by the pressure of the water delivered into the cylinder from the force pump.

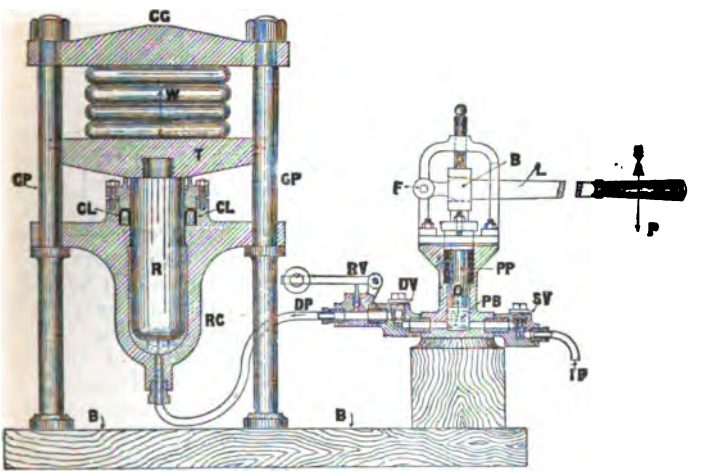

VERTICAL SECTION OF A SMALL BRAMAH HYDRAULIC PRESS.

After what has been written about force pumps, we need not particularise about this part of the machine, except to say that the suction and delivery valve boxes at S V and D V can be disconnected from the pump, and the valve cover-checks removed at any time for the purpose of examining the parts, or of regrinding the valves into their seats. The pump plunger P P, extends through a stuffing-box and gland filled with hemp packing, and is guided by a centrally bored bracket bolted to the top flange of the

* See Lecture XXXV. for Centrifugal Pumps.

pump. The lever L, fits through a slot in this guide-bar, whereby it has an easy free motion, when communicating the force applied through it to the pump plunger. The relief valve R V, has a loaded lever so adjusted as to rise and let the water escape when the pressure exceeds a certain amount. It may also be used for ascertaining the pressure on the object under compression, or for lowering the ram R, by simply lifting the little lever and pressing down the table T, when the water flows easily from the ram cylinder R C, by the delivery pipe D P, and the relief valve. The delivery pipe is made of solid drawn brass, and the ram cylinder is carefully rounded at the bottom end, instead of being flat, in order that it may be of the strongest shape.* The guide pillars G P, are securely bolted to the base B, and to the top cross girder C G, by nuts and washers.

CROSS SECTION OF ORDINARY LEATHER PACKING.

The cup leather packing C L, deserves special attention, because it formed the chief improvement by Bramah on Pascal's press. It consists of a leather collar of ∩ section, placed into a cavity turned out of the neck of the cylinder, and kept there by the gland of the cylinder cover.

This collar is made from a flat piece of new strong well-tanned leather, thoroughly soaked in water, and forced into a metal mould of the requisite size and shape to give it the form of a U collar. The central or disc portion of the leather is then cut out, and the circular edges are trimmed up to a sharp bevel as shown.

The following figure shows an enlarged section of Bramah's packing suitable for a huge press, where the desired shape of the leather collar L C, is maintained by an internal brass ring B R, and an outside metal guard ring G R, resting on a bedding of hemp H. It will be observed at once, from an inspection of this figure, that the water which leaks past the easy fit between the plunger or ram R, and the cylinder C, presses one of the sharp

* In the case of large cylinders for very great pressures, the lower or inner end of the cylinder should be carefully rounded off, both inside and outside. For, if left square, or nearly square, the crystals formed in the casting of the metal naturally arrange themselves whilst cooling in such a manner as to leave an initial stress, and consequent weakness, inviting fracture along the lines joining the inside to the outside corners of the cylinder end. The severe shocks and stresses to which this weak line of division is subjected during the working of the press would sooner or later force out the end of the cylinder, in the shape of the frustrum of a cone, unless the cylinder had been made unnecessarily thick and heavy at the bottom end.

edges of the leather collar against the ram, and the other edge against the side of the bored cavity in the neck of the cylinder, with a force directly proportional to the pressure of the water in the cylinder. By this simple automatic action, the greater the pressure in the cylinder the tighter does the leather collar grip the ram and bear on the cylinder's neck.

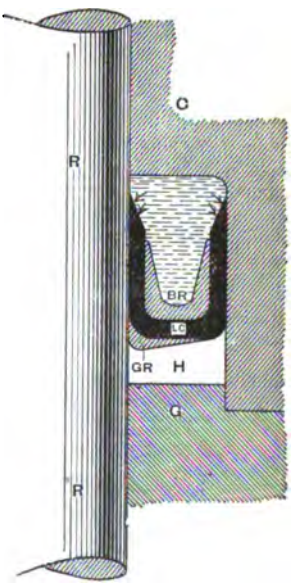

LEATHER COLLAR FOR A LARGE HYDRAULIC PRESS.

Referring again to the figure of the Bramah press, by taking moments about the fulcrum at F, we obtain the pressure Q, on the plunger of the force pump. Neglecting weight of lever and friction, we get :—

$$P \times AF = Q \times BF.$$

$$\therefore \qquad Q = \frac{P \times AF}{BF}.$$

Further, we know that the statical pressure Q, is transmitted with undiminished force to every corresponding area of the cross section of the ram. Hence,

Q : W : : area of plunger : area of ram.

$$\therefore \qquad W \times \text{area of plunger} = Q \times \text{area of ram.}$$

$$\text{Or,} \qquad W \times \pi r^2 = Q \times \pi R^2.$$

Where r = radius of plunger, and R = radius of ram, both in the same unit. Substituting the previous value for Q, and dividing each side of the equation by π, we get :—

$$W \times r^2 = \frac{P \times AF}{BF} \times R^2.$$

$$\therefore \qquad W = \frac{P \times AF}{BF} \times \frac{R^2}{r^2} = \frac{P \times AF}{BF} \times \frac{D^2}{d^2}.$$

Where D and d are the diameters of the ram and plunger respectively.

EXAMPLE VII.—In a small Bramah press, P = 50 lbs., AF = 20 ins., BF = 2 ins., area of plunger = 1 sq. in., whilst area of

ram = 14 sq. ins. Find W, neglecting friction and weight of lever.

ANSWER.—By the above formula :—

$$W = \frac{P \times AF}{BF} \times \frac{R^2}{r^2}.$$

$$\therefore \quad W = \frac{50 \times 20}{2} \times \frac{14}{1} = 7{,}000 \text{ lbs.}$$

EXAMPLE VIII.—In Bramah's original press at South Kensington the plunger is 3 ins. in diameter, and it acts at a distance of 6 ins. from the fulcrum, which is at one end of a lever 10 ft. 3 ins. long, carrying a loaded scale-pan at the other end. What should be the pressure of the water in the press in order to lift a weight of 3 cwts. in the scale-pan, neglecting the weight of the lever? Make a diagram of the arrangement. (S. and A. Exam., 1892.)

ANSWER.—Here $d = 3$ ins., consequently the area of the plunger $= \frac{\pi}{4} d^2 = \cdot 7854 \times 3 \times 3 = 7$ sq. ins., and $BF = 6$ ins.; $AF = 10$ ft. 3 ins. $= 123$ ins.; $P = 3$ cwts. $= 3 \times 112 = 336$ lbs. Now we have to find the pressure per sq. in. on the ram that will balance P, acting with the stated advantage, since the area of the ram is not given.

By the above formula :—

$$W = \frac{P \times AF}{BF} \times \frac{\text{area of 1 sq. in.}}{\text{area of plunger}} = \frac{336 \times 123}{6} \times \frac{1}{7}$$

Or, $W = 984$ lbs. per sq. in.

Hydraulic Flanging Press.—As an example of the practical application of the Bramah press to modern boiler-making, the accompanying illustration shows the form which it takes when used for flanging. It is worked by a high-pressure water supply derived from a central accumulator, which may at the same time be used to work cranes, punching, riveting, and other similar machine tools.

The operation of flanging the end tube-plates of a locomotive boiler is carried out in the following manner :—The ram R is lowered to near the bottom of the hydraulic cylinder H C, in order to leave room to place the heated boiler plate on the movable table T_2. High-pressure water is then admitted from the central accumulator to the auxiliary cylinders A C, thus forcing the side rams S R, with their table T_2, and the plate P vertically upwards,

until the upper surface of the plate bears hard against the bearers B, or internal part of the dies. Water from the same source is now admitted into the hydraulic cylinder H C, and forces up the ram R with its table T_1, supporting columns S C, and the external

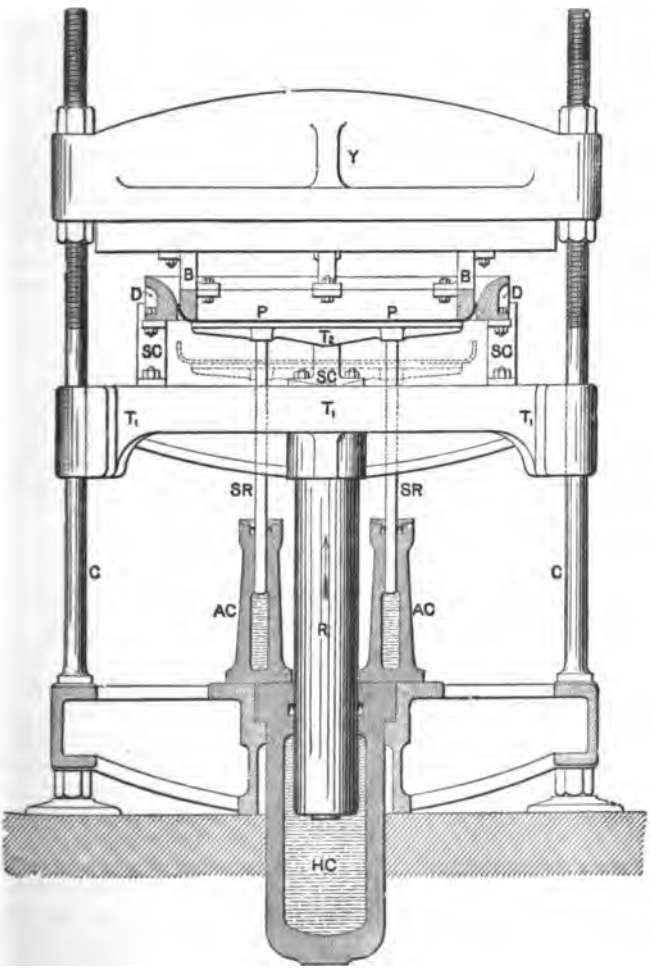

LARGE HYDRAULIC PRESS FOR FLANGING BOILER PLATES.*

* The above figure is a reduced copy of one from Prof. Henry Robinson's book on *Hydraulic Machinery*, published by Messrs. Charles Griffin & Co.

part of the dies D, until the latter has quietly and smoothly bent the heated edge of the plate round the curved corner of the internal bearer B. The ram R is now lowered, carrying with it the table T_1 and dies D, by letting out the water from H C. Then the table T_2 with the flanged plate is lowered by letting out water from A C. The plate is removed from its table, allowed to cool, faced, placed in position in the barrel of the boiler, marked off for the rivet holes, drilled, rimed, and riveted in the usual manner. The student will thus understand what a useful and powerful tool a hydraulic press is to the engineer in the hands of a skilful workman; for, it can be made to do better work in far less time, and with far greater certainty, uniformity, and exactitude, than the boiler-smith can turn out, with any number of hammermen to help him. It is fast replacing the steam-hammer for cressing work, and also steam or belt-driven punching and riveting machines, steam cranes, screw and wheel-gear hoists, as well as the screw press for making up bales of goods.

Hydraulic Jack.—This is a combined force pump and hydraulic press arranged in such a compact form as to be readily portable, and applied to lifting heavy weights through short distances. It therefore effects the same objects as the screw-jack, but with less manual effort and with greater mechanical advantage.

The base on which the jack rests is continued upwards in the form of a cylindrical plunger, so as to constitute the ram of the hydraulic cylinder H C. Along one side of this ram there is cut a grooved parallel guide slot G S, into which fits a steel set pin, screwed through the centre of a nipple cast on the side of the cylinder (not shown in the drawings) for the purpose of guiding the latter up and down without allowing it to turn round. The top of the ram has bolted to it a water-tight cup leather C L, by means of a large washer and screw-bolt.

The action of this cup leather is precisely the same as the leather collar in the cylinder of the Bramah press already described; but it has only to be pressed by the water in one direction —viz., against the sides of the truly-bored cast-steel cylinder, instead of against both the ram and the cylinder neck, as in the former case. The head H and upper portion of the machine is of square section, and is screwed on to the hydraulic cylinder in the manner shown by the figure. It contains a water reservoir W R, which may be filled or emptied through a small hole by taking out the screw plug S P.* In the centre line of the head-

* This screw plug S P is slackened back a little to let the air in or out of the top of the water reservoir when working the jack. There is generally another and separate screw plug opening for filling or emptying the water reservoir, quite independent of the above-mentioned one, which is used in this case for both purposes.

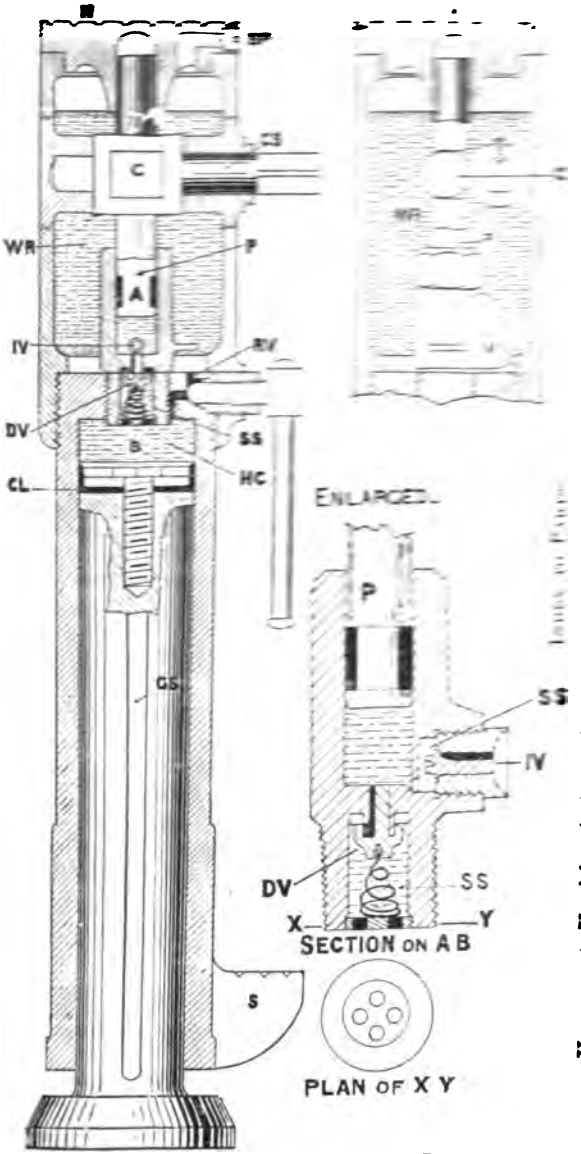

H represents Head for placing under a load.
SP " Screw plug for filling and emptying
WR " Water reservoir.
C " Crank.
CS " Crank shaft.
P " Pump plunger.
IV " Inlet valve.

THE HYDRAULIC JACK.

piece there is placed a small force pump, the lower end of which is screwed into the centre of the upper end of the hydraulic cylinder. This pump is worked by the up-and-down movement of a handle placed on the squared outstanding end of the turned crank shaft C S. To the centre of the crank shaft there is fixed a crank C, which gears with a slot in the force-pump plunger P, and thus the motion of the handle is communicated to the pump plunger. By comparing the right-hand section of the water reservoir, and the section on the line A B, with the vertical left-hand section of the jack, it will be seen where the inlet and delivery valves I V and D V are situated. On raising the pump plunger P, water is drawn from W R into the lower end of the pump barrel through I V, and on depressing the plunger this water is forced through the delivery valve D V, into the hydraulic cylinder, thus causing a pressure between the upper ends of the cylinder and the ram, and thereby forcing the cylinder, with its grooved head H, and foot-step S, upwards, and elevating whatever load may have been placed thereon. Both the inlet and outlet valves are of the kind known as "mitre valves." They have a chamfer cut on one or more parts of their turned spindles, so as to let the water in and out along these channels. The valves are assisted in their closing action by small spiral springs S S, bearing in small cups or hollow centres, as shown more clearly in the case of D V by the enlarged section on A B.

When it is desired to lower the jack, the relief valve R V is screwed back and the water is thus allowed to be forced up again into W R.

Example IX.—Mr. Croydon Marks, in his book on *Hydraulic Machinery*, illustrates and describes another method of lowering the jack-head (first introduced by Mr. Butters, of the Royal Arsenal, Woolwich), where, by a particular arrangement, the inlet and delivery valves are acted upon by an extra depression of the handle, and consequent movement of the pump plunger. He also gives the main dimensions, with a drawing, of the standard 4-ton pattern as used by the British Government, where the ram has a diameter D = 2 ins., the pump plunger a diameter $d = 1$ in.; and the ratio of the leverage of the handle to the crank is 16 to 1. Therefore, from the previous formula we find that :—

$$\textit{The Theoretical Advantage} = \frac{W}{P} = \frac{A\,F}{B\,F} \times \frac{D^2}{d^2} = \frac{16}{1} \times \frac{2^2}{1^2} = \frac{64}{1}.$$

And he instances two trials by Mr. W. Anderson, the Inspector-general of Ordnance Factories, to determine the efficiency of these jacks, where, with a pressure on the end of the working handle of

76 lbs., the theoretical load should have been 76 lbs. × theoretical advantage = 76 × 64 = 4,864 lbs., instead of which it was only 3,738 lbs. :—

$$\therefore \qquad 4{,}864 \text{ lbs.} : 3{,}738 \text{ lbs.} : 100 : x.$$

$$\text{Or,} \qquad x = \frac{3{,}738 \times 100}{4{,}864} = 77 \text{ per cent. efficiency.}$$

In a second trial, a load of 1,064 lbs. required a pressure of 22 lbs. on the handle, and consequently the efficiency at this lighter load, as might be expected, was less, or only 74 per cent.

EXAMPLE X.—With a hydraulic jack of the dimensions given above, and of 77 per cent. efficiency, it is desired to lift a load of 4 tons; what force must be applied to the lever handle?

ANSWER.—By the previous theoretical formula :—

$$W = \frac{P \times AF}{BF} \times \frac{D^2}{d^2}.$$

$$\therefore \qquad P = \frac{W \times BF}{AF} \times \frac{d^2}{D^2}$$

$$\text{,,} \quad = \frac{4 \times 2{,}240 \times 1}{16} \times \frac{1^2}{2^2} = 140 \text{ lbs.}$$

But the efficiency of the machine is only 77 per cent., consequently 140 lbs. is 77 per cent. of the force required :—

$$\therefore \qquad 77 : 100 :: 140 \text{ lbs.} : x \text{ lbs.}$$

$$x = \frac{140 \times 100}{77} = 181{\cdot}81 \text{ lbs.}$$

EXAMPLE XI.—Show, with the aid of sectional sketches, the construction of the ordinary hydraulic lifting jack. If, in such a machine, the mechanical advantage of the lever or handle is 12 to 1, and the diameter of the lifting ram is 2 inches, while the diameter of the plunger is $\frac{7}{8}$ of an inch, what weight can be lifted theoretically when a pressure of 50 lbs. is applied to the lever handle? (S. & A. Exam., 1891.)

ANSWER.—The hydraulic jack has been fully described and illustrated in this lecture.

Let D = Diameter of ram = 2 inches.
,, d = ,, plunger = $\frac{7}{8}$ inch.
,, n = Mechanical advantage of lever = 12 : 1.
,, P = Effort applied at end of lever = 50 lbs.
,, W = Weight raised.

If Q denotes the pressure on the plunger, caused by the effort P applied at the end of the lever, then :—

$$Q = P\,n.$$

But,
$$\frac{W}{Q} = \frac{\text{area of ram}}{\text{area of plunger}} = \frac{D^2}{d^2}.$$

$$\therefore \quad \frac{W}{P\,n} = \frac{D^2}{d^2}.$$

This is a formula giving the relation between W, P, n, D, and d, which is also true for the hydraulic press.

Substituting the above values in this formula, we get :—

$$\frac{W}{50 \times 12} = \frac{2^2}{(\frac{7}{8})^2}.$$

$\therefore$ **W = 3,134 lbs., *or* = 1·4 tons, nearly.**

Hydraulic Bear.—This is another very useful application of the hydraulic press and force pump. It is used in every shipbuilding-yard and bridge-building works. By comparing the drawing with the index to parts, it may be seen that its construction and action are similar to the hydraulic jack just described in full detail, and we need say nothing more than direct the student's attention to the action of the raising cam, and to the means by which the apparatus is lifted and suspended. In order to raise the punch P, for the admittance of a plate between it and the die D, the relief valve R V, must first be turned backwards, and the lever L, depressed. This causes the corner of the raising cam R C, to force the hydraulic ram H R, upwards, and the water from the hydraulic cylinder H C, back into the water reservoir W R. The relief valve R V, may now be closed and the plate adjusted in position. Then the pump lever P L, can be worked up and down until the punch P, is forced through the plate, and the punching drops through the die hole D, in the metal frame M F, to the ground, or into a pail placed beneath to receive it.

The whole bear is suspended by a chain (worked by a crane or other form of lifting tackle) attached to a shackle, whose bolt passes through a cross hole in the back of the metal frame M F, just above, but a little to the front of, the centre of gravity of the machine. This hole and shackle are not shown in the drawing, but the student can easily understand that the hole would be bored a little above where the letters R C, appear on the side view,

and that the chain would pass clear of the pump lever, since this works well to the right-hand side of the bear.

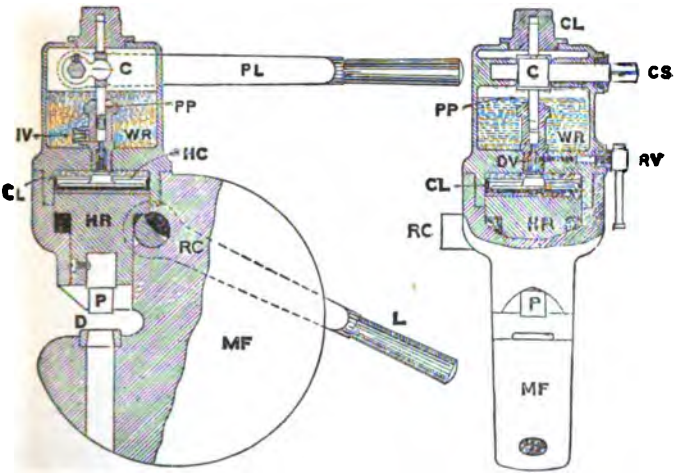

SIDE VIEW AND SECTION. END VIEW AND SECTION.

THE HYDRAULIC BEAR, OR PORTABLE PUNCHING MACHINE.

INDEX TO PARTS.

P L	represents	Pump lever.	H C	represents	Hydraulic cylinder.
C S	,,	Crank shaft.	C L	,,	Cup leather.
C	,,	Crank.	H R	,,	Hydraulic ram.
P P	,,	Pump plunger.	R C	,,	Raising cam.
W R	,,	Water reservoir.	L	,,	Lever for R C.
I V	,,	Inlet valve.	P	,,	Punch.
D V	,,	Delivery valve.	D	,,	Die ring
R V	,,	Relief valve.	M F	,,	Metal frame.

Lead-covering Cable Press. — Hydraulic presses are now employed for making lead pipes, and for covering electric light cables with a close-fitting tube of lead. For the former purpose the lead is heated until it is nearly melted in a strong chamber from which it is forced by rams to squirt through a die at the top of the machine. A mandrel projects into the centre of the die, and, consequently, the lead issues as a continuous tube.

The accompanying figure illustrates a press for covering electric cables with lead in this manner, as carried out by Messrs. Siemens Brothers, at their Woolwich works. It consists essentially of a receiver in which two rams work, and which contains a mandrel

and matrice. The lead is melted in the melting pot at the top by gas or petroleum, and is then poured into the receiver below.

The cable enters at one side of the receiver, and passes through the mandrel and leaves at the other, while as soon as the rams begin to force their way into the receiver, the lead casing is formed round the cable.

The matrice can be so nicely adjusted by means of steel cones, that a lead casing of perfectly uniform thickness of a fraction of a millimetre, can be obtained. An excellent feature of this press is,



PRESS FOR COVERING CABLES WITH LEAD, BY FRIED. KRUPP GRUSONWERK, GERMANY.

that it possesses two rams which, by distributing the pressure more uniformly, ensure a more regular casing than is possible with only one, as is usually the case. The two rams are connected together by an adjusting apparatus so that they will both move forward at the same rate. The mandrels and matrices can easily be changed to suit cables whose diameters range from $\frac{1}{8}$ in. to $2\frac{3}{4}$ ins.

Hydraulic Accumulator.—The demand for hydraulic power to work elevators, cranes, swing bridges, dock gates, presses, punching and riveting machines, &c., being of an intermittent nature—at one moment requiring a full water supply at the maximum pressure, and at another a medium quantity, whilst in many cases all the machines may be idle—it is evident that if an engine with pumps were devoted to supplying this demand in a direct manner, the power thereof would have to be equal to the greatest requirements of the plant, and would have to instantly answer any and every call from the same. In the case of a low-pressure supply, as for lifts, this difficulty is best overcome by placing one tank in an elevated position at the top of the hotel or building where the lift is required, and another tank below the level of the lowest flat. Then a small gas engine working a two or three-throw pump, or a Worthington duplex steam pump, may be used to elevate the water more or less continuously from the lower to the higher tank. The "head" of water in the elevated tank will, if sufficient, work the lift at the required speed, and the discharged water from the hydraulic cylinder will enter the lower tank, to be again sent round on the same cycle of operations. Should the lift be stopped for any considerable time, then a float in the upper tank, connected by a rope or chain with the shifting fork for the belt-driven pumps (in the case of the gas engine) will force the belt over on to the loose pulley, or shut off the steam from the Worthington pump. And when the water falls in the upper tank, the float will cause a reverse movement of the rope and shift the belt to the tight pulley, or open the steam valve, and so start the pumps.

When the pressures required are great, such as for cranes, &c., where 700 lbs. on the square inch is considered a very medium pressure, an elevated tank would be out of the question, for it would have to be fully 1600 feet high in order to exert this force and to overcome friction. Under these circumstances recourse is had to a very simple and compact arrangement called an accumulator, of which we here give a lecture diagram, without any details of cocks or valves, and automatic stopping and starting gear. A steam engine, or other motor, works a continuous delivery pump, of the combined piston and plunger type, without an air vessel, as already illustrated in this lecture. The water from the pump enters the left-hand branch pipe leading into the foot of the accumulator cylinder, and forces up the accumulator ram with its crosshead or top T-piece and the attached weight or dead load, until the ram has reached nearly to the end of its stroke. Then the top of the T-piece, or a projecting bracket on the side of the wrought-iron cylinder containing the dead load, engages with and lifts a small weight attached to a chain passing over a pulley

fixed to the guide frame or to the wall of the accumulator house. This chain is connected directly to the throttle valve of the steam supply pipe, or to the belt-shifting gear if the pump is driven by belt gearing, and being provided with a counter-weight, the motor and pump are automatically stopped by the raising of the weight and the chain in the accumulator house. Should the water which has been forced into the accumulator cylinder be now used by a crane or other machine, the load on the ram causes it to follow up and keep a constant pressure on the water. The starting weight falls as the receding T-piece or bracket descends, and thus pulls the starting chain, and opens the steam engine throttle valve, or shifts the belt from the loose to the fixed pulley, and again sets the pump to work. Should the hydraulic machines be working continuously, then the pump is kept going, for the water from it passes directly on to the machines, and only the surplus water finds its way into the accumulator cylinder if the pump's supply exceeds the demand of the machines for water.

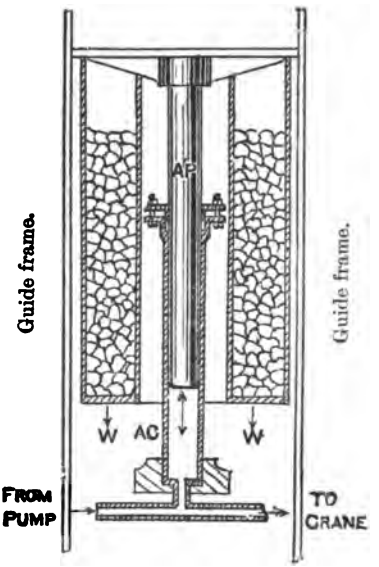

THE HYDRAULIC ACCUMULATOR.

INDEX TO PARTS.

A C for Accumulator cylinder.
A P ,, Accumulator plunger or ram.
W ,, Weight or load contained in an annular cylinder of wrought iron and suspended from the top of T-piece or crosshead.

The annular cylinder of wrought iron is generally filled with scrap iron, iron slag, sand, or other inexpensive heavy material. The accumulator cylinder A C, has a stuffing-box and gland at its upper end. A coil of hemp woven into a firm rectangular section and smeared with white lead is placed in the bottom of the stuffing-box. The gland is screwed down on the top of this packing until at the normal pressure the water in the cylinder cannot leak past it. Cup leather packing is seldom used for this simple form of accumulator; just the ordinary packing that would be used for pump rods is found to answer all requirements. This is the

simplest form of accumulator which we have here described, but other forms will be illustrated in the next lecture.

EXAMPLE XII.—Describe and sketch in section an hydraulic accumulator, showing how the ram is kept tight in the cylinder. An hydraulic press, having a ram 16 inches in diameter, is in connection with an accumulator which has a ram 8 inches in diameter and is loaded with 50 tons of ballast; what is the total pressure on the ram of the press? (S. & A. Exam., 1892.)

ANSWER.—The first part of the question is answered by the previous figure and by the text.

By Pascal's Law the pressure *per square inch* in the accumulator is equal to the *pressure per square inch in the* hydraulic press. Consequently :—

$$\frac{\textit{Total Pressure on Press}}{\textit{Total Load on Accumulator}} = \frac{\textit{Cross Area of Press Ram}}{\textit{Cross Area of Accumulator Ram}}$$

$$\frac{P}{50} = \frac{\pi}{4} \times 16^2 \div \left(\frac{\pi}{4} \times 8^2\right) = \frac{16^2}{8^2}.$$

$$\therefore \qquad P = \frac{50 \times 16 \times 16}{8 \times 8} = 200 \text{ tons.}$$

Hydraulic Cranes.—Another very common application of hydraulic power is the working of cranes for handling goods at wharves, warehouses, or railway depôts, and we illustrate a simple one for the latter purpose In this crane, the lower part of the pillar forms the cylinder for a ram H R, which carries a pulley M P, at its upper end and is actuated by the water pressure. A chain, fastened at one end to the crane pillar, passes over this pulley and then round two fixed ones F P, before going to the jib pulley. Hence, when the ram is forced up, the chain will be pulled up twice as far. A small slide valve, actuated by the handle V H, controls the supply of water to the hydraulic cylinder. By means of this valve, the cylinder is put into communication with either the pressure or the exhaust pipe, or it may be cut off from both. The weight of the ram and load attached to the hook H, are utilised to drive out the water on the return stroke.

Hydraulic Wall Crane.—Our next figure shows a crane on the same principle fixed to the wall of a warehouse or shed. In this case, however, the motion of the ram is magnified eight times by placing four pulleys side by side on the end of the large ram which here moves downwards. The slewing of this crane is also accom-

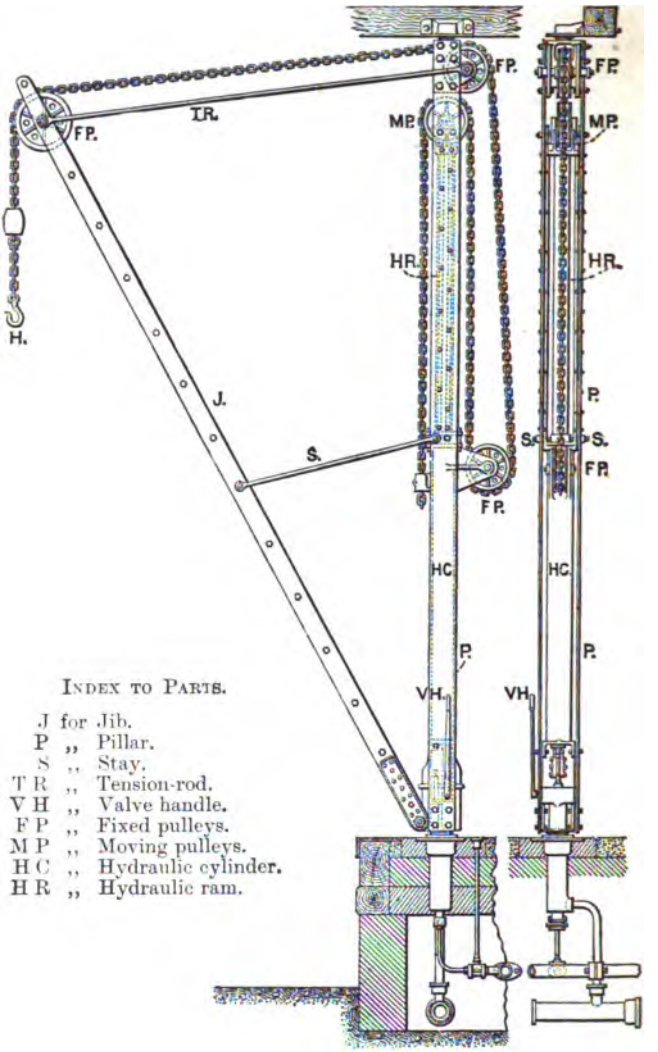

HYDRAULIC CRANE.

HYDRAULIC WALL CRANE.

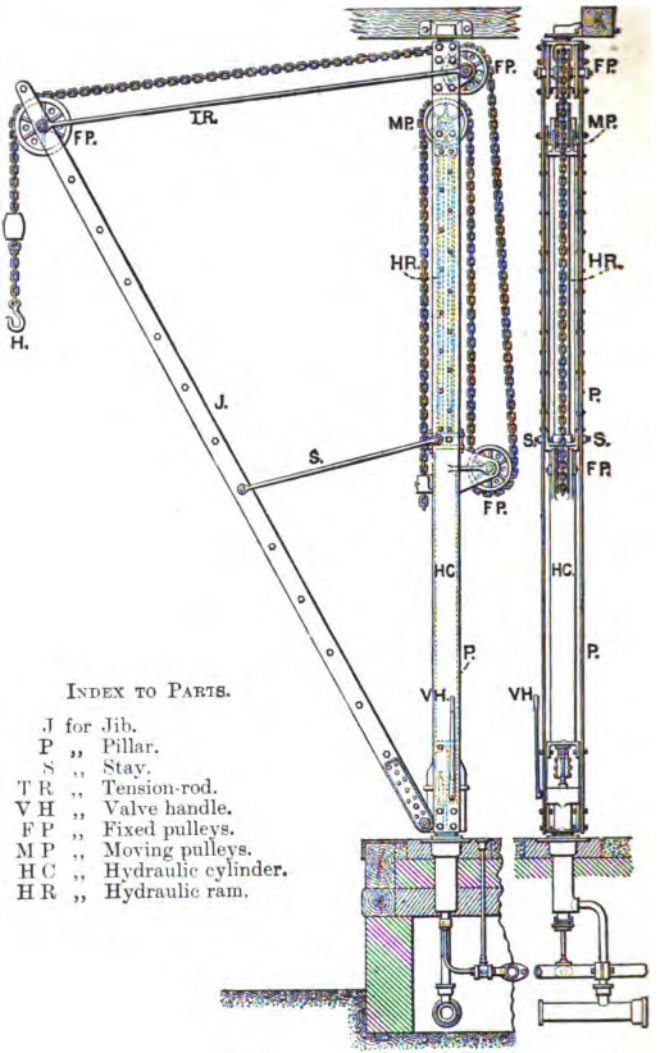

HYDRAULIC CRANE.

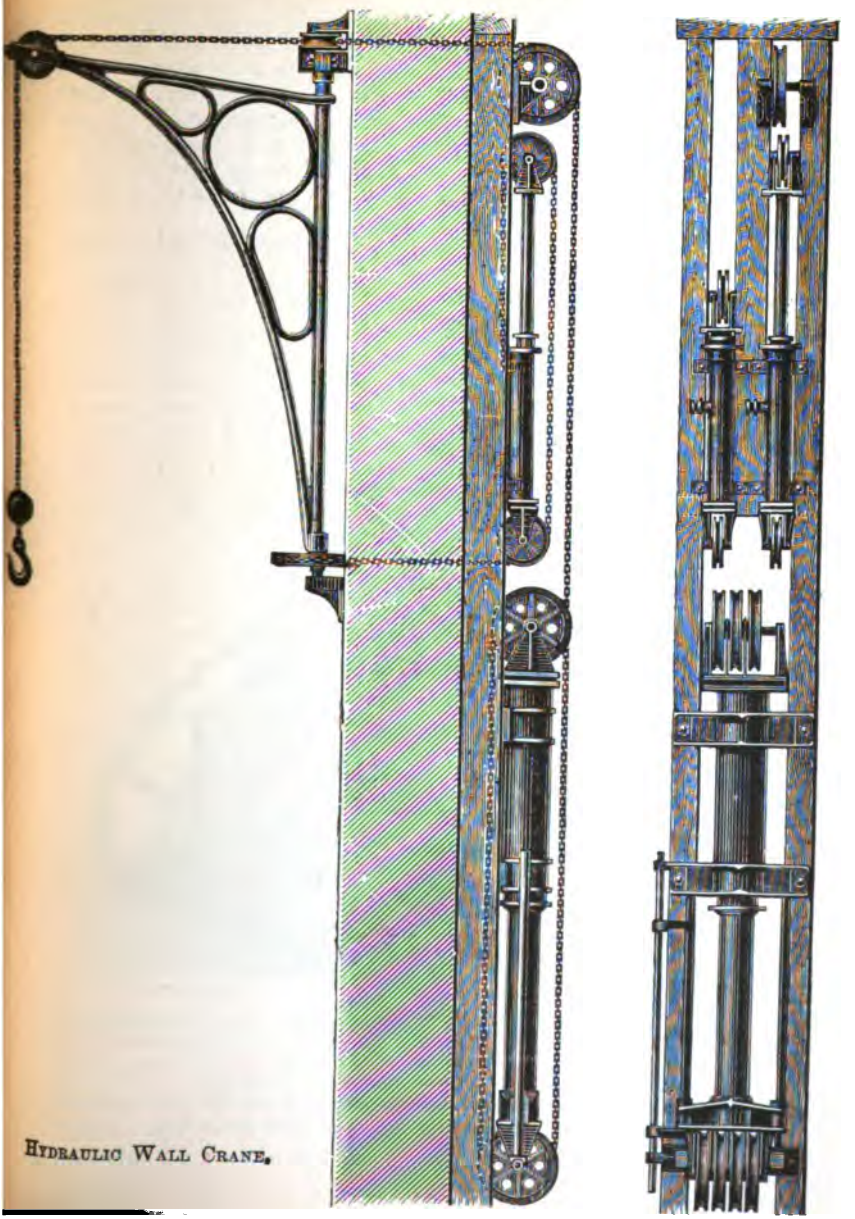

HYDRAULIC WALL CRANE.

plished by hydraulic means as follows:—Each end of a chain, which passes round a wheel at the bottom of the crane, is taken over a pulley on a separate small ram, and then fixed to the framework. Matters are so arranged, that when these two smaller rams are at their half strokes the crane projects at right angles to the wall. If water be admitted below one of the rams that end of the chain is forced up and the crane is hauled round. At the same time, the other ram is pulled down by the chain so as to be ready to bring the crane back when required.

Movable Jigger Hoist.—For lifting light loads, say under a ton,



MOVABLE JIGGER HOIST BY W. H. BAILEY & CO., LTD., MANCHESTER.

from a ship's hold, jigger hoists are often employed. The lifting chain or rope is wound on the large drum, while the ram actuates another chain coiled on a small drum on the same axis. Conse-

quently, the load is lifted very rapidly, as the motion is magnified first by the sheaves on the ends of the ram and cylinder, and then by the wheel and axle arrangement. The jigger stands on the quay and the lifting chain passes over a pulley hung from one of the ship's derricks. The valve gear can be worked, if desired, by a rope from the ship's deck.

Double Power Hydraulic Crane.—A disadvantage of hydraulic pressure apparatus is, that, as a rule, the same amount of water is used with a light load as with a heavy one, any surplus energy being consumed in fluid friction. To reduce this loss Lord Armstrong employed a combined ram and piston as shown in the figure on next page.

With the valves in the position shown, both ends of the cylinder are in communication with the supply pipe, and the ram is moved forward by the pressure on the difference between the areas of the piston and ram. The water used also corresponds to this difference of area because that in the right-hand end of the cylinder is forced round to the left, and only the remainder comes from the accumulator. Now, if we require to lift a greater load than the crane will raise under these conditions, V_3 must be closed and V_4 opened. This allows the water at the front of the piston to escape, and we get the full pressure on the back of the piston. To lower the load, V_1 is closed and V_2 opened. Then, the water escapes from the left of the piston partly to the exhaust and partly to the other end of the cylinder. The relief valve allows a little water to escape back to the supply pipe whenever the pressure in the valve chamber rises above that of the accumulator, owing to the sudden closing of the outlet valve. This gear is designed to work horizontally in a chamber sunk into the ground below the crane.

Hydraulic Capstan.—When a continuous rotary motion is required from hydraulic power, the usual method is to put three single-acting oscillating cylinders in symmetrical positions round the shaft, with all three pistons acting on one crank pin, while the motion of the cylinder itself uncovers the openings for the inflow and exit of the water at the proper time. As an example, we illustrate a hydraulic capstan for use on dock quays. In this one there are four cylinders with their mid positions 90° apart. A plunger in each acts on the crank below the capstan. The water enters and leaves by passages in the trunnions on which the cylinders swing, and these passages are opened at the right moment by the oscillation of the cylinder

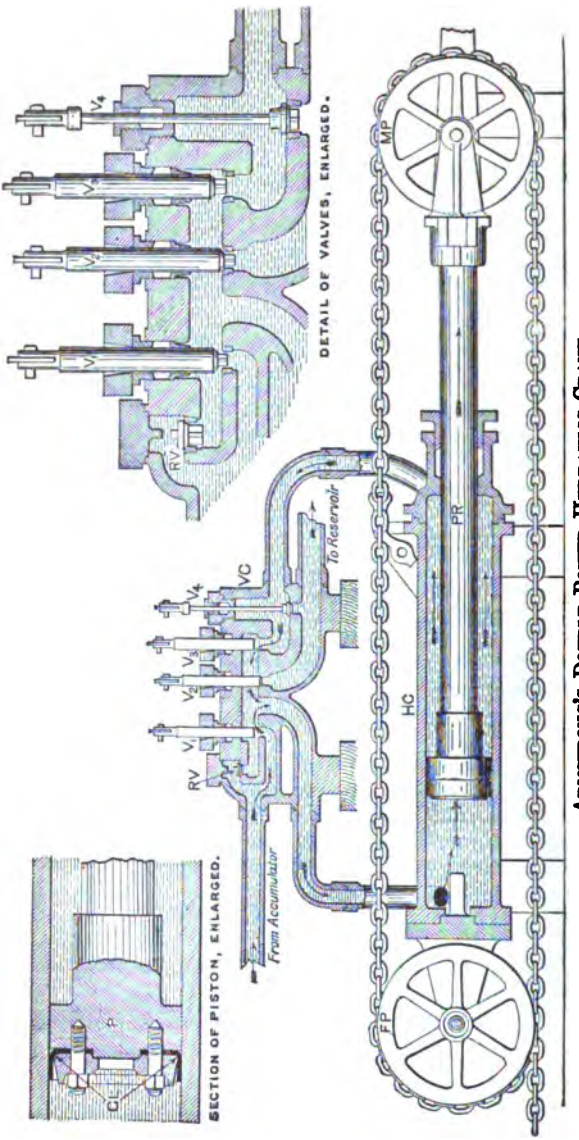

Armstrong's Double Power Hydraulic Crane.

HC for Hydraulic cylinder.	V_1 for Inlet valve.
PR " Piston-rod.	V_2 V_4 " Outlet valves.
P " Piston.	V_3 " Connecting valve.
CL " Cup leather.	R V " Relief valve.
VC " Valve chamber.	



HYDRAULIC CAPSTAN BY W. H. BAILEY & CO., LTD., MANCHESTER

LECTURE XXXIII.—QUESTIONS.

1. One side of a reservoir has a slope of 12 vertical to 5 horizontal; what is the whole amount of the pressure of the water against 50 feet of its length, when the depth of the water is 12 feet? *Ans.* 243,750 lbs.

2. In an empty dock the water is level with the sill at the lowermost edge of the dock gate, the level of the water on the opposite side of the gate being 10 feet above the sill. The dock gate is 10 feet wide, find the pressure in pounds on the dock gate. If the water were at a level of 5 feet in the dock, the level outside being the same as before, how much would the pressure on the gate be relieved? *Ans.* 31,250 lbs.; 7,812·5 lbs.

3. State Archimedes' principle. A cylindrical can is 6 inches in diameter and 30 inches deep, and is required, when empty, to stand in a bath of water 30 inches deep without being lifted up. To what weight must the can be loaded, the weight of a cubic foot of water being 62½ lbs.? *Ans.* 30·679 lbs.

4. A rectangular tank, 4 feet square, is filled with water to a height of 3 feet. A rectangular block of wood, weighing 125 lbs., and having a sectional area of 4 square feet, is placed in the tank, and floats with its sides vertical and with this section horizontal. How much does the water rise in the tank, and what is now the pressure on one vertical side of the tank? *Ans.* 2 inches; 1,253 lbs. (S. & A. Exam., 1892.)

5. The total force in the direction of the motion of a piston is the cross-sectional area of the cylinder multiplied by the pressure. Why is this so, the piston not having a plane surface? (S. & A. Adv. Exam., 1898.)

6. An escape valve, loaded partly by a weight and partly by a spring, is fitted to a main conveying water under pressure, and is required to open automatically when the water pressure rises above a certain amount. Sketch and describe the construction of such a valve when arranged on the double beat principle, and explain clearly the hydrostatic principle involved therein. (S. & A. Exam., 1890.)

7. Prove that when a thin spherical shell is exposed to the bursting pressure of gas or liquid the stress in the material is half as great as that within the curved surface of a thin cylindrical shell exposed to the like pressure, each shell being of the same thickness and diameter. (S. & A. Exam., 1891.)

8. Sketch a combined plunger and bucket pump with index of parts, explaining its use and action, also sketch its application to the lifting of water from deep mines. Suppose a pump raises 5,000 gallons every half minute from a depth of 600 feet with 30 per cent. loss in system, what is the horse-power required? *Ans.* 1,874 H.P.

9. Describe a force pump for supplying water to the accumulator of hydraulic cranes. Sketch a section through the plunger and valves.

10. Sketch and describe a force pump having a solid plunger, showing the construction of the valves. The diameter of the plunger is 2½ inches, and it is driven by a crank 2 inches in length making 30 revolutions per minute. Find the cub. ins. of water pumped in 5 minutes. *Ans.* 2,945 cub. ins.

11. Describe and illustrate by a longitudinal section, and such other views as may be necessary, the construction and action of a double-acting pump

and its valves, supposing the pump cylinder to be of 3¼ inches internal diameter, and to work at a pressure of 700 lbs. per square inch. Of what materials would the several parts be constructed? (S. & A. Exam., 1893.)

12. A vertical single-acting pump has to elevate water 50 fathoms. The bore of the pump is 6 inches; stroke, 6 feet; number of up strokes, 10 per minute. Find (*a*) the pressure per square inch on the pump backet when it is at the bottom of its stroke; (*b*) the weight of water discharged per minute; (*c*) the horse-power of the engine required to drive the pump, supposing 30 per cent. of the engine-power to be lost by friction, &c. Sketch an arrangement of the kind. *Ans.* (*a*) 130·28 lbs. per square inch; (*b*) 736·31 lbs.; (*c*) 9·56 H.P.

13. Give any method with which you are acquainted whereby the valves in a pumping engine may be relieved from the shock due to the inertia of the water in the mains.

14. A pump for exhausting air from a receiver has a solid piston and one valve in the casing. Describe, with a sketch, the construction of the pump, and explain the nature of the improved form known as Sprengel's pump, where a small portion of mercury forms the piston, and no valve is required. (S. & A. Exam., 1889.)

15. Describe and show, with the aid of necessary sketches, the construction of the "Pulsometer." Describe how it works, and indicate the contrivances introduced to promote the steady flow of water and to prevent sudden shocks upon the apparatus. Is the pulsometer an economical arrangement for raising water? Give reasons for your answer. What, if any, are its advantages over the ordinary piston pump? (S. & A. Hons. Exam., 1896.)

16. Sketch in section the cylinder, ram, and leather collar of an hydraulic press. Explain the principle of the press and the manner in which the escape of water is prevented. Example—The sectional area of the plunger of the force pump is $\frac{1}{50}$ that of the ram, and the leverage gained by the pump handle is 12 to 1, find the pressure on the ram when a force of 60 lbs. is exerted at the end of the pump handle. *Ans.* 36,000 lbs.

17. Describe, with a sectional sketch, a hydraulic press where the ram is actuated in both directions. Show the position and forms of the cup leathers.

18. The return stroke in an hydraulic press is often accomplished by forming the ram like a piston with a very large piston-rod. Sketch in longitudinal section such a press, showing the arrangement of the leathers. What will be the relative speeds of the forward and return strokes of the ram when the larger and smaller diameters are 15 inches and 14 inches respectively, the pumps for the supply of water running at the same speed in both cases? (S. & A. Adv. Exam., 1894.)

19. In some hydraulic presses a single valve, held down by a lever and weight, is used both to indicate and relieve the pressure. Sketch the valve in position and explain its action.

20. Describe clearly and show with sketches the construction and action of any one form of portable hydraulic riveting machine with which you are acquainted. Show clearly the valves and connections by which the pressure is applied to close the rivet, and how the pressure is released and the tool withdrawn from the rivet head when the riveting is completed. How is the water pressure conveyed to the machine? (S. & A. Hons. Exam., 1895.)

21. What are the advantages in forging large masses of steel by hydraulic pressure over the same operation performed by the steam hammer? Show clearly, with the assistance of the necessary sketches, the method em-

ployed in hydraulic forging presses for bringing the ram or pressing surface rapidly back from the work after each application of the pressure. (S. & A. Hons. Exam., 1896.)

22. Sketch a section through an hydraulic lifting jack and hydraulic bear, and describe the manner in which the pressure exerted on the handle is transmitted to the ram.

23. A 4-ton hydraulic lifting jack has a lifting ram of 2 inches in diameter, and a pump plunger of 1 inch in diameter. The jack is worked by a lever handle, the leverage being 16 to 1. What pressure must be applied at the end of the handle in order to lift a load of 25 cwts., if the efficiency of the machine is 80 per cent.? Make a vertical section of the jack, showing the valves and the mode of connecting the lever with the pump plunger. How can the weight be lowered slowly and regularly without jerks? (S. & A. Adv. Exam., 1894.)

24. Explain, with the aid of a sectional sketch, the action and construction of the hydraulic jack. How is the pressure taken off and the load slowly lowered? If the ram is 2 inches in diameter, the pump plunger $\frac{7}{8}$ inch, and the mechanical advantage of the handle 10, what is the total mechanical advantage, neglecting friction? (S. & A. Adv. Exam., 1897.)

25. Make a sketch of a 10-ton hydraulic jib crane in which the lifting cylinder is carried in the pillar or post of the crane. What would be the diameter of ram required in the arrangement you adopt, supposing water to be supplied to the crane at a pressure of 700 lbs. per square inch, neglecting friction, &c.? (S. & A. Exam., 1891.)

26. What is the object of a relief valve in an hydraulic crane, and where is it placed? Sketch a longitudinal section through the cylinder and ram of a crane working at two powers. Explain the mode of action. (S. & A. Exam., 1888.)

27. Describe, with sketches, some form of hydraulic lift, and the manner in which it is worked. (S. & A. Exam., 1889.)

28. Describe with sketches a direct-acting 80 foot hydraulic lift, to carry a load of 1 ton, the ram is 4 inches diameter, and the moving parts are balanced by a counterweight and chain. The lift is worked from a tank of water 40 feet above the highest level of the platform and an intensifier must be used. (S. & A. Hons. Exam., Part II., 1898.)

29. Make a section through the cylinder of an hydraulic crane with two powers as applied for raising weights. Give a general description of the crane, and explain the mode of working it by referring to your sketch.

30. Describe the general construction of the lifting apparatus in the hydraulic crane, making a sketch of the cylinder and ram. Show the method of obtaining *two* powers from a single cylinder. In what way is the *pulley principle* applied in such cranes?

31. In an hydraulic crane with two powers show (1) the apparatus for lifting the weight, (2) the method of slewing or rotating the jib of the crane.

32. Explain the advantage to be derived from making the length of stroke of an hydraulic engine adjustable. Describe and give sketches of a construction for this purpose.

LECTURE XXXIV.

HYDRAULIC APPLIANCES IN GAS WORKS.

CONTENTS.—Labour-Saving Appliances in Modern Gas Works—Pumping Engines and Accumulator—Example I.—Differential Accumulator—Brown's Steam Accumulator—Small Hydraulic Accumulator Plant—Arrol-Foulis' Gas Retort Charging Machine—Foulis' Withdrawing Machine for Gas Retorts—Results of Working—Questions.

Labour-Saving Appliances in Modern Gas Works.*—In no industry have the conditions of labour undergone more radical and rapid changes than in large modern gasworks. Until recently, the coal was emptied by hand from railway waggons or from carts at the most convenient position for the retort benches. If the lumps of coal were too large, they were broken up by manual labour, and the retorts were charged, as well as discharged, by hand. The surplus coke, beyond what was required for the furnaces, was quenched, wheeled into a yard, and there screened and filled into carts or waggons, all by hand labour.

In modernised works, the coal is usually delivered direct from the railway truck into the hopper of the mechanically-driven coal breaker. After passing through this machine, it is raised by an elevator to a large hopper, which is so fixed that the coal can be automatically delivered into the hopper of any of the charging machines. The charging of the retorts is then performed by means of a hydraulic charging machine more evenly and otherwise better than by hand. After carbonisation, the coke is withdrawn from the retorts by a hydraulic drawing machine. These two operations now entail a minimum of labour and inconvenience from heat to the attendants. The surplus

* I am indebted to Mr. Andrew S. Biggart, of Sir William Arrol & Co., Ltd., Glasgow, for the drawings from which the three electros of the General Arrangement, Charging, and Drawing Machines were made. I am also indebted for the information contained in Mr. Biggart's paper which he read before the 1895 Glasgow meeting of the Institution of Mechanical Engineers, as well as to Mr. Foulis, the General Manager of the Glasgow Corporation Gas Trust for showing me the whole of the plant in operation.

coke, guided in its descent by shoots, falls into a bogie underneath the floor, and is run out to the yard by small locomotives. In some instances conveyors, which are placed underneath the stage floor, carry the coke to circular revolving screens, whence it is delivered into large storage hoppers, railway waggons, or bags for small consumers.

The old methods involved continuous and repeated operations performed by hand; while the new are such that no hand labour is employed in dealing with the coal from the time it leaves the railway truck until it arrives there again in the form of coke. Hand labour is thus entirely superseded by mechanical power, to the great advantage of both the labourer and the employer. The number of men required in the retort house under the new system is less than half that required under the old method. The saving which this represents, after allowing for maintenance of plant and interest on additional capital, will average about one shilling per ton.

Pumping Engines and Accumulator.—The general arrangement of this portion of the plant is illustrated by the following side elevation and plan. The steam engine and pumps are situated either in the main engine room of the gasworks or in a convenient house not far removed from the steam boilers; while the accumulator may be placed in an annex, where there is plenty of head room for the guide timbers. From what has already been said about the construction and action of the Armstrong accumulator in the preceding Lecture, and by carefully comparing the present figures with the index to parts (which has been tabulated in nearly the exact sequence of the operations) the student will have no difficulty in understanding the generating plant which serves to supply hydraulic power to the charging and drawing machines in the retort houses.

The steam engine drives the rams R of the pumps P direct from a back extension of the piston-rods. From the pumps the water is forced into the accumulator cylinder A C at such a pressure that, acting on the accumulator ram, it is capable of lifting the heavy dead-weight bolted to the upper end. This weight is provided with guide arms G A, bearing upon planed iron rails fixed to the vertical guide timbers G T. When the guide arms have reached a certain height, the one at the right hand begins to lift a weight attached to a chain on the weighted lever of the throttle valve T V. During the remainder of the ascent of the accumulator the automatic starting chain A S is slackened until the throttle valve is closed, and the engine is stopped before the guide arms reach the cross beam, which connects the upper ends of the guide timbers. Should

the chain stick, or anything fail about this automatic system of stopping the engine, then a second chain, which connects the weight at the end of the relief valve R V to the counterpoise ball

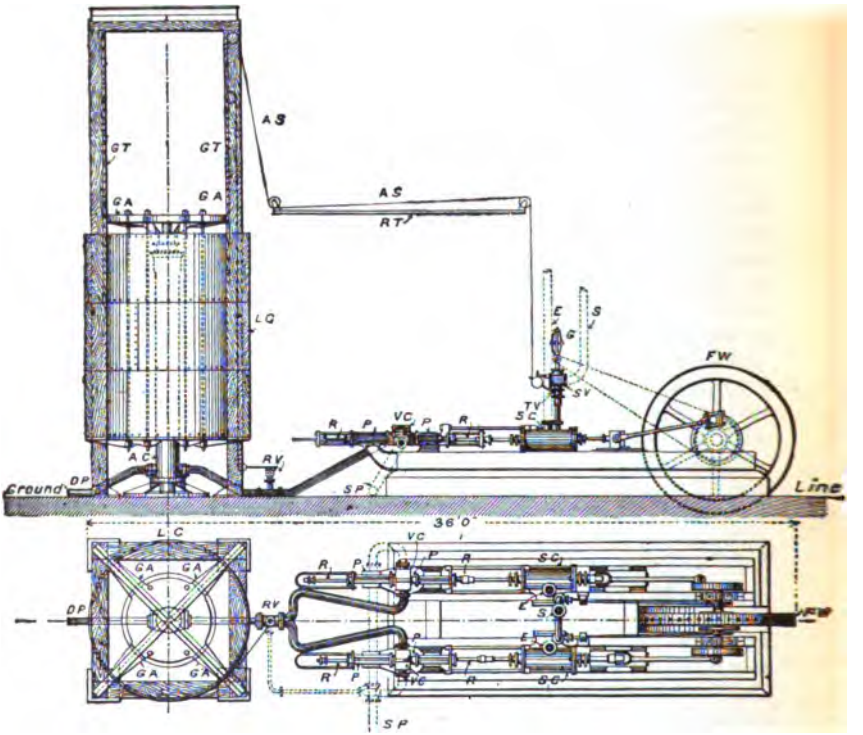

GENERAL ARRANGEMENT OF PUMPING ENGINES AND ACCUMULATOR FOR WORKING GAS RETORT CHARGING AND WITHDRAWING MACHINES.

INDEX TO PARTS.

S	for Steam Pipe.	VC	for Valve Chest for Pumps.
SV	,, Stop Valve.	R	,, Rams.
TV	,, Throttle Valve.	P	,, Pumps.
AS	,, Automatic Starting and Stopping Apparatus.	RV	,, Relief Valve.
SC	,, Steam Cylinder.	AC	,, Accumulator Cylinder.
E	,, Exhaust Pipe.	DP	,, Delivery Pipe.
G	,, Governor.	GA	,, Guide Arms.
FW	,, Flywheel.	GT	,, Guide Timbers.
SP	,, Suction Pipe.	LC	,, Load Casing.
		RT	,, Roof Tie-Rods.

attached to the chain A S, is tightened up just before the guide arms reach the uppermost limit of their travel.* This action releases the downward pressure on the relief valve, and permits sufficient water to escape to prevent any further elevation of the accumulator ram. The governor G now prevents the engine from racing. When water is used by any of the hydraulic machines it flows to them from the accumulator cylinder through the delivery pipe D P. This allows the accumulator ram and weight to sink until the ball attached to A S re-asserts its pull on the throttle valve, and, automatically opening it, starts the engine.

It is evident that if a set of engines and pumps were devoted to the direct supply of high-pressure water to several machines, their output would have to be equal to the greatest requirements of the plant at any instant; but by the introduction of the accumulator and its automatic starting and stopping gear we have a simple means of ensuring a constant supply of water at the desired pressure with a smaller engine.

An accumulator, therefore, performs several very important functions in a most efficient manner:—

(1) It acts as a reservoir for the storage of energy.
(2) It acts as a regulator of pressure.
(3) It acts like a flywheel in taking up and giving out power in direct sympathy with the immediate wants of supply and demand.
(4) It acts as an elastic buffer, and prevents the breakage of joints, &c.
(5) It automatically controls the motive power.

The efficiency of an accumulator has been proved to be as high as 98 per cent., only 1 per cent. being lost through friction in charging, and 1 per cent. in discharging it, as tested by pressure gauges on the supply and discharge pipes. Its total store of energy is, however, comparatively small, since it is only equal to the potential energy of the weight raised. Hence, if W lbs. be the total weight raised in the accumulator, and H feet the difference of height between its highest and lowest positions, we have:—

$$\left.\begin{array}{c}\textbf{Energy Stored in}\\ \textbf{Accumulator}\end{array}\right\} = \mathbf{W\,H\ ft.\text{-}lbs.} = \frac{\mathbf{W\,H}}{\mathbf{33{,}000 \times 60}}\ \mathbf{H.P.\text{-}hours.}\dagger \quad \text{(I)}$$

* Another arrangement is to pass this second vertical chain through a hole in a projecting plate fixed to the right-hand guide arm G A, and then attach its upper end to the top cross beam. If the accumulator should rise too high, then the plate catches an enlarged portion of the chain and opens the relief valves.

† One horse-power = 33,000 ft.-lbs. of work per minute, hence, 1 horse-power hour is 33,000 × 60 or 1,980,000 ft.-lbs.

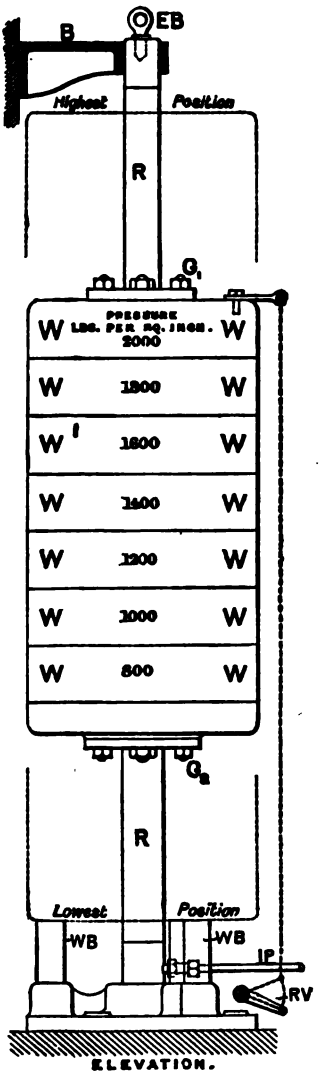

ELEVATION.

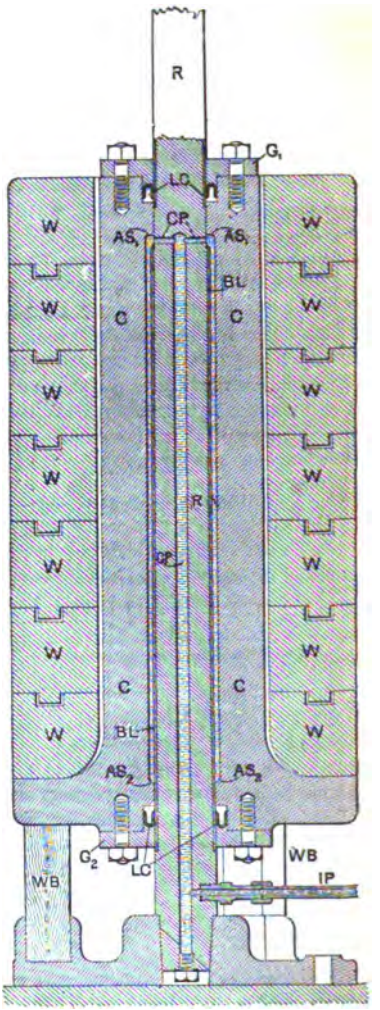

VERTICAL SECTION.

TWEDDELL'S DIFFERENTIAL ACCUMULATOR.

EXAMPLE I.—The accumulators used in connection with the hydraulic power supply in Glasgow are 18 inches in diameter, and have a free lift of 23 feet. The total load on each is 127 tons. Find the pressure of the water and the maximum energy stored in each accumulator, neglecting friction.

ANSWER.—

Pressure of water $= p = \frac{W}{A}$.

" " $= \frac{127 \times 2{,}240}{\cdot 7854 \times 18 \times 18} =$ **1,120 lbs. per sq. in.**

Energy stored $= W H = 127 \times 2{,}240 \times 23$.

" $= 6{,}543{,}000$ ft.-lbs., or **3·3 H.P.-hours.**

INDEX TO PARTS.

I P	for Inlet Pipe from pump.
R	,, Ram of accumulator.
B L	,, Brass Liner on lower part of R.
C P	,, Central and Cross Passages for water.
C	,, Cylinder.
$A S_1$, $A S_2$	,, Annular Spaces from top and bottom of cylinder.
G_1, G_2	,, Glands (top and bottom).
L C	,, Leather Cup Packings.
W	,, Weights.
W B	,, Wooden Blocks.
B	,, Bracket (at top).
E B	,, End Bearing.

It will be seen from this example how small the total store of energy is, and that accumulators would be quite useless to maintain the supply for any length of time. One of the real advantages of the accumulator arises from the fact that we may use its energy for a very short time at a high rate. For instance, although the accumulator in the above example is only capable of maintaining 3·3 H.P. for a whole hour, it could exert 19·8 H.P. for ten minutes, or 198 H.P. for one minute.

Differential Accumulator.—Although it has only been found necessary to employ a water pressure of 400 lbs. per square inch in the charging and drawing machines for gas retorts, which we will describe later on, and, further, since it is advisable with them to have a considerable volume of water in the accumulators when many machines have to be worked simultaneously, yet it may not be out of place to describe here the differential accumulator designed by Mr. Tweddell for his smaller kinds of hydraulic

tools, since there may be cases in which space and compactness are of considerable importance. From the foregoing elevation and enlarged vertical section it will be seen that the ram R consists of a vertical fixed shaft secured at the top by a bracket B, and at the bottom by a footstep. The lower half of this shaft is of larger diameter than its upper half, a brass liner B L being shrunk on the former part. Moreover, this lower portion of the ram has a central passage C P drilled axially along it, with a cross passage just above the upper end of the brass liner. Through these passages water is admitted from the inlet pipe I P, which is connected directly to the force pumps. This water finds its way into an annular space A S_1, A S_2, which is the clearance between the outside of the brass liner and the inner bore of the heavy press or cylinder C. Surrounding the outside of the cylinder are placed a number of cast-iron or lead weights W which fit into each other, and form the dead load along with the weight of the cylinder. At the top and the bottom of the cylinder there are suitable glands G_1 and G_2 containing the usual leather cup packings L C. When the machine is idle the bottom flange of the cylinder rests upon wooden beams W B. It will now be readily understood that the effective area of the ram is *only* the difference between the cross areas of the brass liner B L and the upper part of the ram R, instead of the whole area of the ram as in the previous case. Hence, a very great pressure may be obtained from a small weight. For example, should the annular area representing the difference in size between the brass liner and the upper part of the iron ram be 5 square inches, and the total weight of the cylinder and its surrounding cast-iron blocks be 2,000 lbs., then, neglecting the friction at the glands, the pressure would be $2{,}000 \div 5$, or 400 lbs. per square inch. This accumulator will store up an equal amount of energy, as in the previous case, if the dead weight and height of the lift are the same since their stored energy depends directly upon $W \times H$. The volume of water contained in the accumulator will, however, be comparatively small, and hence it will fall more quickly for a certain amount of water used by the hydraulic machines which it drives. As will be seen from the left-hand figure, a relief valve R V is worked by a chain connecting an outstanding arm on the uppermost weight to the end of the lever; also any desired pressure up to 2,000 lbs. per square inch, or more, may easily be obtained from this accumulator with a comparatively small dead load and space.

Brown's Steam Accumulator.—Another very simple form of accumulator, which has proved very effective both for land purposes and on board ship, is that designed and made by Mr. A.

Betts Brown, of the Rosebank Iron Works, Edinburgh. It consists of a steam cylinder S C fitted with a piston P and a piston-rod or ram R. Steam is supplied direct to this cylinder from the boiler and presses on the piston P in opposition to the

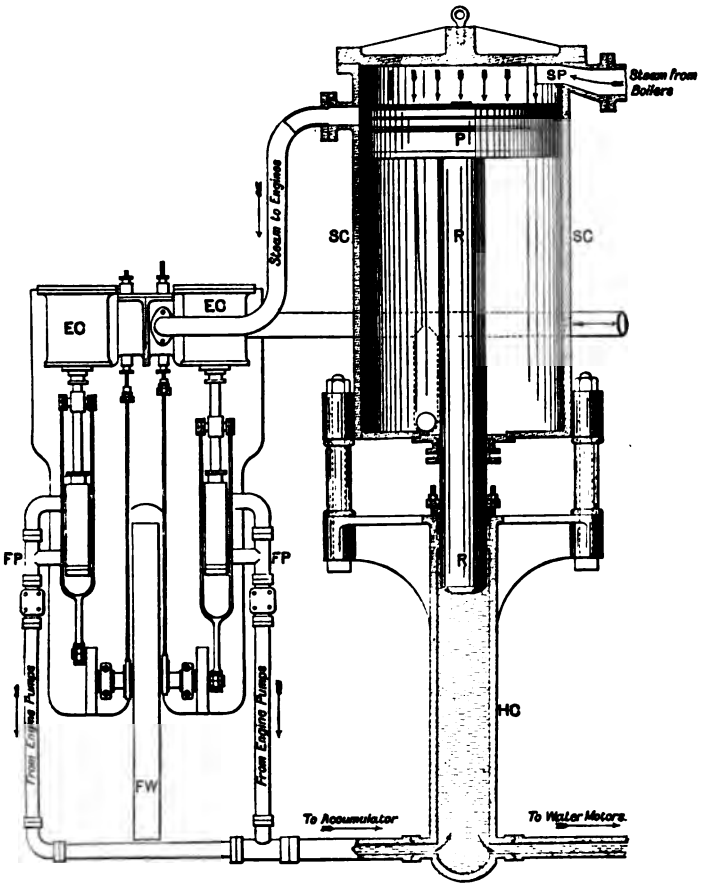

BROWN'S STEAM ACCUMULATOR.

INDEX TO PARTS.

S P for Steam Pipe from Boilers.	H C for Hydraulic Cylinder.
S C ,, Steam Cylinder.	E C ,, Engine Cylinders.
P ,, Piston working in S C.	F P ,, Force Pumps.
R ,, Ram attached to P	E ,, Exhaust Pipe.

water forced into the hydraulic cylinder H C by the force pumps F P, which are worked by a pair of engines. An exhaust pipe E carries away the exhaust steam from the engine cylinders E C and the bottom of the large steam accumulator cylinder S C.



SMALL HYDRAULIC ACCUMULATOR PLANT.

Suppose that the piston P is at the bottom of its cylinder, then the boiler steam not only fills the portion above the piston but passes on to the engine cylinders and therefore works the pumps

and forces up the ram and piston to the top of their stroke, when the piston gradually closes the steam passage leading to the engines until they stop. Should any of the hydraulic machines be now put into action the water flows to them from the hydraulic cylinder, the ram and piston descend and the engines are again set into motion to keep up the demand and again close the engine steam pipe. With a steam cylinder of 36 inches diameter and a ram of 9¼ inches (or, ratio of areas 15 to 1) Mr. Brown is able with about 50 lbs. steam pressure per square inch to maintain a pressure of 750 lbs. per square inch in the hydraulic mains leading to water motors, steering, stopping, and starting gear, or, in the case of a gas works, to the charging and drawing machines.

Small Hydraulic Accumulator Plant.—Should the gas works be a small one, then a much less expensive accumulator plant may be employed, such as that illustrated. This figure is sufficiently self-descriptive after what has been said about the larger plant.



DIRECT ACTING STEAM PUMP.

The small pumping engine, or donkey pump, which supplies water of the desired pressure to the accumulator is also shown in a perspective view. Steam is admitted to the steam

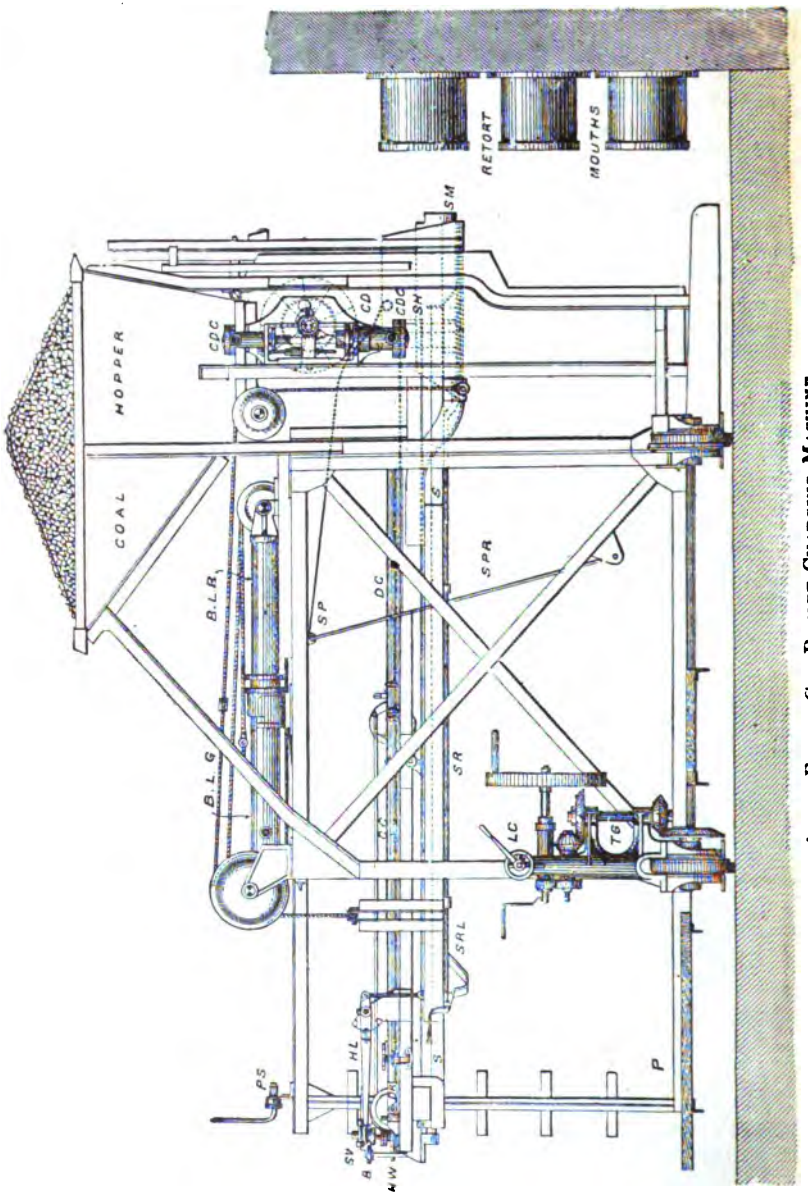

ARROL-FOULIS GAS RETORT CHARGING MACHINE.

cylinder by piston valves, actuated by a connecting-rod and lever, while the double-acting pump is fitted with a solid piston plunger and an air vessel.

Arrol-Foulis Gas Retort Charging Machine.—In replacing hand labour for the charging gas retorts by a hydraulic machine several important requirements have to be effected:—

(1) The machine should be easily moved parallel to the retort bench at the proper distance therefrom.

(2) It must be capable of being connected with the hydraulic pressure pipe at every position.

(3) The shoot mouth should be easily raised or lowered to suit the highest or lowest retort.

(4) The shoot mouth should be easily entered into the mouth of the retort before filling it with coal.

(5) The coal hopper should contain at least a sufficient quan-

INDEX TO PARTS.

P	for Platform (for attendant).	C D	for Coal Drum.
T G	,, Travelling Gear.	S V	,, Slide Valve.
P S	,, Pressure Swivel.	C C	,, Charging Cylinder.
L C	,, Lifting Cock.	S	,, Spear.
B L C	,, Beam Lifting Cylinder.	S H	,, Spear Head.
B L R	,, Beam Lifting Ram.	D C	,, Drawing Cylinder.
S R L	,, Shoot Rod Lever.	S P	,, Swing Plate.
S R	,, Shoot Rod.	S P R	,, Swing Plate Rods.
S M	,, Shoot Mouth.	H W	,, Hand Wheel.
H L	,, Hand Lever.	B	,, Bell.
C D C	,, Coal Drum Cylinders.		

tity of coal to charge a complete set of retorts without requiring to be refilled.

(6) The exact quantity of coal required for the charge of each retort should be easily regulated, and the regulator should be capable of dealing with all the sizes of coal in use.

(7) The charge should be laid evenly and of the desired depth from back to front without any special effort on the part of the attendant, and without loss of time.

(8) The platform of the attendant should be placed in the most convenient position for actuating all the motions, and at the same time protecting him from the heat emanating from the retorts.

(9) The whole machine should require a minimum of attention and repair. It should also be able to withstand the rough usage of retort house workmen, as well as the hydraulic pressure, without undue leakage or giving way in any of its vital parts.

These several requirements have been very ingeniously worked out and applied by Sir William Arrol and Mr. William Foulis in their patent hydraulic charging machine, shown by the accompanying figure, as follows:—

(1) The whole machine with its load of coal is supported on a pair of rails, placed parallel to the retort bench, and moved by travelling gear T G. In the illustration ordinary hand gear is shown, but in the latest machines a hydraulic motor of special design has been applied with excellent results.

(2) A pipe is fixed the whole length of the retort bench at a convenient height and distance therefrom, and it is always kept charged with water from the accumulator at the full working pressure of 400 lbs. to the square inch. At suitable distances along this pipe there are attached ordinary armoured flexible hose pipes, which may be connected to the pressure swivel P S. From this swivel copper pipes lead to the lifting cock L C and slide valve S V.

(3) The beam carrying the shoot mouth, shoot rod S R, spear S, charging cylinder C C, and drawing cylinder D C, is raised and lowered by turning the lifting cock L C to the right or left, and thereby admitting water to the beam lifting cylinder B L C.

(4) When the shoot mouth S M is fairly opposite one of the retort mouths it is pushed forward by the shoot-rod lever S R L, and the hand lever H L is turned to admit water to the slide valve S V and work the charging cylinder C C, so as to push the spear S and spear head S H into the retort, having a quantity of coal in front.

(5) The coal hoppers are made to contain from 2 to 5 tons.

(6) The feeding gear consists of an open coal drum C D, which is divided into segmental compartments, each of which can contain a certain quantity of coal. It is turned through one or two divisions at regular intervals by a hydraulic ram with rack and ratchet gear, so as to permit the desired quantity of coal to fall into the shoot. A plate, which acts as a flap valve, is so fixed in front of the drum by a lever and weight, that it presses against the face of the drum, and prevents the small coal from falling down past the face of the drum.

(7) The coal falls from the hopper in front of the pusher plate or spear head S H, and is delivered into the retort by a series of six or seven successive strokes, each stroke being shorter than the previous one. This is accomplished by means of a shaft carrying a set of stops placed on the beam alongside the spear S. This shaft is automatically turned a certain amount during each return stroke, so as to bring the stops into position in rotation. The forward and return strokes of the spear are caused by two



General View of Arrol-Foulis Charging Machine.

hydraulic rams working in the cylinders C C and D C, which are regulated by the hand lever H L. This lever also serves to lower the spear head when entering the retort for pushing in the coal, and to raise it clear from the bottom of the retort during the return stroke. It also causes the revolution of the stopper shaft. The inclined form of the spear head and these successive strokes ensure the charge being evenly distributed along the retort, and the depth is regulated by putting in more or less coal at each stroke, as previously explained.

(8) The platform P is placed at the back of the machine, so that the attendant has the levers within easy reach, and he is placed as far as possible from the heat of the retorts.

(9) Great attention has been given to the several details of the machine, so as to render it as durable as possible. The reason for adopting this comparatively low pressure is, that the power required for the different motions is so small that if a higher pressure were employed the rams would be inconveniently small. In fact, with 400 lbs. pressure it had been found in some instances that rams of only $1\frac{1}{4}$ inch diameter gave ample power.

Foulis' Withdrawing Machine for Gas Retorts.—After the coal has been carbonised and converted into coke, it has to be withdrawn from the retorts before putting in a new charge. This is done by a machine which is similar to that used for charging, and travels along the same rails. The withdrawing machine consists of a frame supported on a truck and carrying a rake for pulling out the coke. The head of this rake can swing backwards into a horizontal position so as to clear the coke when being moved inwards, but goes back to the vertical and dips into the coke on its return stroke.

The beam B carrying the rake can be raised or lowered, and the rake moved out and in, in the same manner as the corresponding parts of the charging machine. As, however, the withdrawing machine is comparatively light, it is found quite sufficient to use hand travelling gear T G to make it move along the rails.

The exhaust water is led to a tank E T, from which it flows to a spray pipe S P and plays on the rake head to keep it cool and help to quench the coke.

Results of Working.—Mr. Biggart says that the number of retorts charged or drawn per hour by these machines varies to a considerable extent in actual work. In some cases, owing to special circumstances, not more than twenty-four per hour are available for each machine; while in other more favourable instances as many as forty-eight per hour are allotted to each, and even with this larger number a reasonable time remains for



rest for the attendants at the end of each hour. The labour of charging the retorts and withdrawing the coke is much lightened

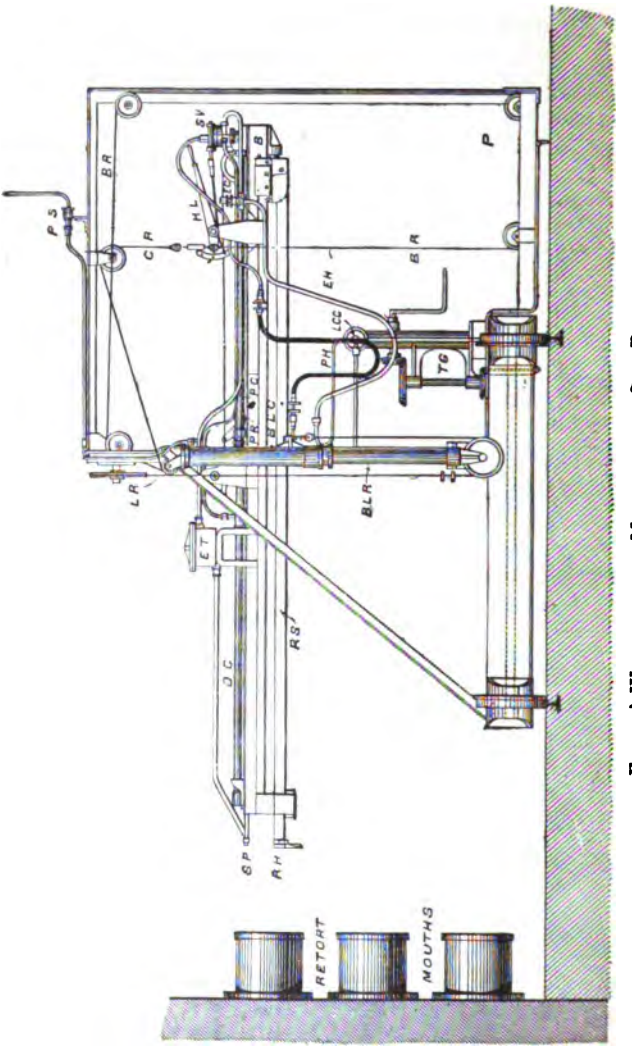

FOULIS' WITHDRAWING MACHINE FOR GAS RETORTS.

by these mechanical means, and the number of retorts charged and drawn for each man employed is largely increased. It

might at first be imagined that coal placed in retorts in only six to eight large charges by the machine would not be so evenly laid as a much larger number of smaller charges put in by hand. The machine, however, lays the coal by far the most evenly, owing partly to the shape of the pusher head, which is bevelled so as to allow the small ridge of coal raised in pushing forwards to fall back when its support is removed on the withdrawal of the pusher head. Another advantage possessed by machine work over hand labour is that the charging is done more quickly, and thus there is a diminished loss of gas before the retort doors are closed.

Apart from any other consideration, the mechanical charger could not fail to prove beneficial in view of the greatly improved conditons under which it enables work of a most trying nature to be carried on. The old method of hand charging was a severe ordeal for the stokers, requiring great exertion to get through

INDEX TO PARTS.

TG	for Travelling Gear.	PH	for Pressure Hose.
PS	,, Pressure Swivel.	PC	,, Pushing Cylinder.
LCC	,, Lifting Cylinder Cock.	PR	,, Pushing Ram.
B	,, Beam.	RS	,, Rake Spear.
BLC	,, ,, Lifting Cylinder.	RH	,, ,, Head.
BLR	,, ,, ,, Ram.	EC	,, Exhaust Cock.
LR	,, Lifting Rope.	EH	,, ,, Hose.
BR	,, Balancing Ropes.	ET	,, ,, Tank.
CR	,, Check Rope.	SP	,, ,, Spray Pipes.
HL	,, Hand Lever.	DC	,, Drawing Cylinder.
SV	,, Slide Valve.	P	,, Platform (for Attendant).

the work in the shortest time possible, while exposed throughout to a high heat. Such adverse conditions are now entirely done away with where mechanical stoking obtains. The single lever by which the whole of the operations are controlled is worked from such a position that the attendant is quite removed from the discomfort of close proximity to a high heat, while at the same time the former severe bodily exertion is replaced by light and easy work. Even greater improvements in the conditions of labour arise from the introduction of the drawer, which accomplishes, under all the better conditions attending the use of the charger, work of a still more trying nature. The withdrawing of the hot coke from the retorts was work for which even the stokers themselves, accustomed as they were to it, admitted that mechanical appliances were required. Here again all is worked by a single lever, in such a position as to remove the attendant from the former discomforts of withdrawing the coke at a white heat at the mouth of the open retort.

LECTURE XXXIV.—QUESTIONS.

1. Sketch and describe the general arrangement of pumping engines and accumulator as used for supplying hydraulic power to the mechanical stoking appliances in a gas works.

2. Make a vertical section of an accumulator, and explain the manner in which this apparatus enables us to store up and give out energy. If the ram of the accumulator be 17 inches in diameter, what should be the load in order to obtain a water pressure of 700 lbs. on the square inch? *Ans.* 70·9 tons.

3. Sketch and describe some arrangement of an hydraulic accumulator by which a pressure of 10 tons to the square inch can be obtained for testing purposes, with pumps working at a pressure not exceeding 3 tons to the square inch. (S. and A. Exam., 1890.)

4. Describe, without going into detail, the engines, pumps, accumulator, and one or two of the appliances likely to be used by customers of an hydraulic company. (S. and A. Adv. Exam., 1897.)

5. If you desire to obtain great pressure with a small dead load, what form of accumulator would you employ? Give a vertical section and a description of the construction and action of the accumulator you have selected. Why is it inadvisable to use one with a very small ram?

6. If you desire to obtain a pressure of 1,200 lbs. per square inch, and you are limited to a dead weight of 1 ton, what effective area would you require, and what would be the diameter of the larger part of the ram if the smaller be 6 inches in diameter, in the case of a differential accumulator having a total efficiency of 90 per cent.? What would be the diameter of the ram if you used a solid one?

7. Sketch and describe Brown's Steam Accumulator. Mention any advantages and disadvantages which you consider it possesses with respect to other forms of accumulator.

8. Suppose the effective steam pressure in the steam cylinder of a Brown's Accumulator to be 60 lbs. on the square inch, and that you require a water pressure of 1,000 lbs. per square inch, with a ram of 20 square inches in cross section, what will be the diameters of the ram and steam piston if 2 per cent. be lost in friction?

9. Sketch the construction and describe the action of the Arrol-Foulis hydraulic apparatus for charging gas retorts. Mention the several advantages of employing this machine as against hand labour.

10. Sketch the construction and describe the action of the Foulis hydraulic apparatus for withdrawing the coke from gas retorts. Mention the several advantages of employing this machine as against hand labour.

11. What is the use of an intensifier or intensifying accumulator in the working of hydraulic machinery? Sketch such an apparatus, and explain fully its principle and construction: give also one example of the application of the intensifier to hydraulic machinery. (S. and A. Adv. Exam., 1896.)

LECTURE XXXV.

HYDROKINETICS.

CONTENTS.—Energy of Flowing Water—Bernouilli's Theorem—Jet Pumps, Injectors and Ejectors—Hydraulic Ram—Example I.—Velocity of Efflux and Flow of Water from a Tank—Measurement of a Flowing Stream—Rectangular Gauge Notch—Thomson's Triangular Notch—Measurement of Head—Measurement of Large Streams—Horse-Power of a Stream—Vortex Motion—Free Vortex—Forced Vortex—Pressure due to Centrifugal Force—Reaction of a Jet—Reduction of Pressure Round an Orifice—Impact—Loss of Energy—Resistance of a Pipe—Hydraulic Mean Depth—Questions.

Energy of Flowing Water—Bernouilli's Theorem.—When a liquid is flowing in a pipe or channel, it possesses kinetic energy in virtue of its motion in addition to the potential energy due to its position and pressure; and the total energy is the sum of these three.

Let v = Velocity of the liquid.
,, h_1 = Length of its pressure column.
,, h_2 = Height above the datum level.
,, H = Height of the free surface of the still water above the datum level.
,, m = Mass of the portion of the liquid under consideration.
,, g = Acceleration due to gravity.
,, f = Frictional loss of head.

Then,

The energy of pressure $= m\,g\,h_1$
,, of position $= m\,g\,h_2$
And, ,, of motion $= \frac{1}{2}\,m\,v^2$.

Hence, The total energy $= m\,g\left(h_1 + h_2 + \frac{v^2}{2\,g}\right)$. (I)

Or, Energy per unit mass $= g\left(h_1 + h_2 + \frac{v^2}{2\,g}\right)$. (I_a)

It follows from the principle of the *Conservation of Energy*, that so long as no work is spent on friction, this total remains constant whilst the water flows along the pipe or channel. Therefore, for a frictionless liquid in which there are no eddies :—

$$h_1 + h_2 + \frac{v^2}{2\,g} = \text{a constant} = \text{H}. \quad . \quad . \quad . \quad \text{(II)}$$

If, p = Pressure per unit area at any point in the liquid,
And, w = Weight of unit volume of the liquid,

Then, $h_1 = \frac{p}{w}$;

Hence, $\frac{p}{w} + h_2 + \frac{v^2}{2g}$ = a constant = H. . . . . (III)

This equation is known as *Bernouilli's Theorem.*

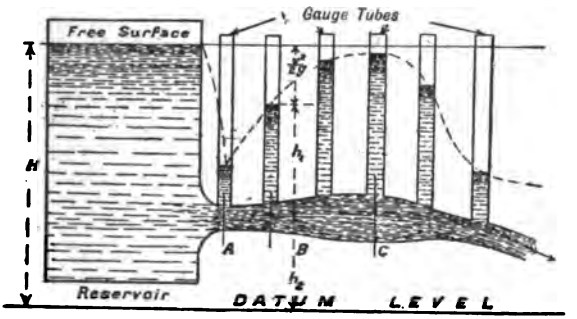

PRESSURES IN A FRICTIONLESS PIPE.

If a certain amount of energy mgf be absorbed by friction between some vertical datum section such as A and the section under consideration which may be at B or C.

Then, $\frac{p}{w} + h_2 + \frac{v^2}{2g} + f$ = a constant = H. . . (IV)

Let a = The cross area of the pipe at any section.
" v = " velocity of the water at the same section.
" Q = " quantity or volume of water passing every section in unit time. This volume is constant for all sections during a steady flow of the liquid.

Then, $a\,v = Q$; or, $v = \frac{Q}{a}$. . . . . (V)

This shows, that the velocity is great when the cross section of the pipe is small, and *vice versâ.*

In the figure, we have shown small vertical gauge tubes placed at intervals A, B, C, &c., along the pipe, in order to indicate the pressure of water at these points by the height to which it rises in them. It will be observed that where the pipe is level or nearly so, the pressure is greatest where its cross section is largest and consequently the velocity is least. This follows directly from

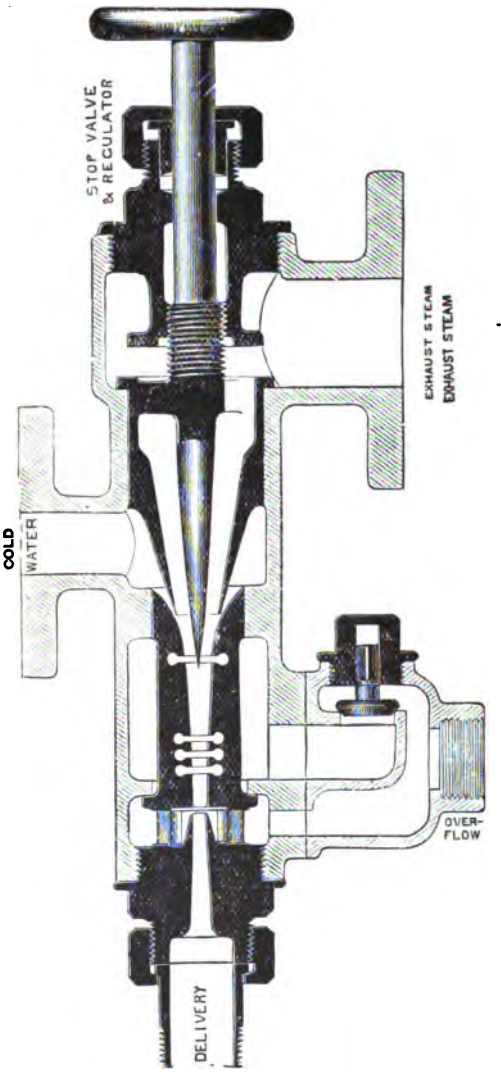

EXHAUST STEAM EJECTOR.

Bernouilli's theorem, since the height h_2 above the datum level is practically constant.

Jet Pumps, Injectors, and Ejectors. — From the previous illustration and explanation of the alteration in the pressure of water as it flows through a pipe of varying size, it will be readily understood that if a stream of water be rapidly forced through a tapered passage, its pressure may be so lowered below the surrounding atmosphere, that it can draw in more water from another source connected to the smaller end of the taper. If the whole of the water be then conducted along a gradually enlarged passage, its pressure will increase and the outflow can take place at a higher level than the intake of the induced stream, but lower than the free surface of the driving water. The late

Prof. James Thomson, of Glasgow University, designed his jet pump upon this principle, and Prof. Bunsen used a jet of water to produce a vacuum in his air pump. Steam jets, compressed air, and water under pressure, have frequently been used to create a blast of air, to feed petroleum into furnaces, to produce a sand blast for engraving or cleaning purposes, and to transfer granular materials from one position to another.

Injectors for feeding steam boilers with water also work upon this principle; but since they are greatly assisted by the condensation of the steam as it comes into intimate contact with the suction water, the latter can be forced into the same boiler or another vessel having the same pressure as, or even a higher pressure than, that which supplies the injector with steam.* Exhaust steam ejectors also depend upon the above action, and are sometimes used to replace both the ordinary jet condenser and air pump in connection with condensing engines. As will be seen from the accompanying figure, when the regulating stop valve is screwed upwards by turning the hand-wheel, the exhaust steam from the engine cylinder enters by the right-hand upper pipe and mixes with cold water coming through the left-hand one, thereby becoming condensed and producing the desired vacuum. The combined condensed steam and condensing water then flow from the delivery pipe into the hot well, whilst any throttled discharge, or some of the live steam that may have been used for blowing through and starting the ejector, can escape into the same place by the overflow pipe. As we shall prove further on, apparatus of this kind cannot have a very high efficiency since the mixing up of quick and slow moving streams results in a considerable loss of mechanical energy.

Hydraulic Ram.—This apparatus was invented about 100 years ago by a Frenchman named Montgolfier. It is one of the simplest, most durable, and efficient machines for raising water to a greater height than the source of supply. The energy stored up in water descending from a comparatively low elevation is utilised to raise part of the same water to a much higher level, of from three to thirty times the vertical height of the original fall. The principle upon which the apparatus works will be understood from



PRINCIPLE OF THE HYDRAULIC RAM.

* For a description of Giffard's and other steam injectors see the author's *Text-Book on Steam and Steam Engines.*

a consideration of the foregoing figure. If the valve V be held down firmly on its seat, and the left-hand vessel be filled with water to a certain height, it will rise to the same level in the right-hand open pipe. If the valve be now released for a short time, water will flow under the action of gravity along the horizontal passage and escape at the open valve with a velocity proportional to the square root of the "head" or vertical height of the free surface above the valve. On suddenly closing the valve, the kinetic energy of the moving water will be partly spent in raising the right-hand column to a greater height than the free surface of the water in the left-hand vessel. Now, if we introduce a check valve at the foot of the long column, so as to prevent this water from falling down again, and an air vessel to act as a cushion, we can repeat the operation continually, so as to produce a flow of water up the pipe.

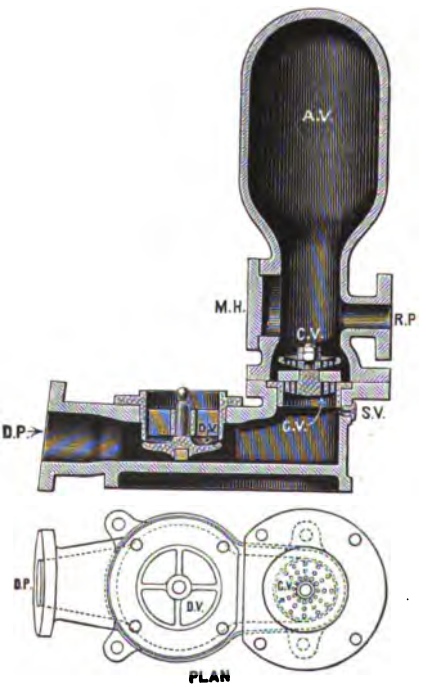

HYDRAULIC RAM, BY THE GLENFIELD COMPANY, KILMARNOCK.

The machine, as made and supplied by the Glenfield Company of Kilmarnock, is illustrated by a vertical section and plan in the accompanying figure. Water flows from a cistern, tank, pond, or dam, through a cast- or wrought-iron pipe, technically called the drive pipe D P, to a hollow casting containing two valves. The first of these is named the escape or dash valve D V, which opens downwards, and the other the check valve C V, which opens upwards. Over the latter is fixed an air vessel A V, having a manhole door M H to the left and a delivery pipe, which is technically termed a rising pipe R P, to the right. If the

apparatus and all the pipes are duly connected to the supply and delivery tanks, and the dash valve D V be held up, until the water from the source of supply has filled not only the drive pipe D P, but also risen through the check valve C V and rising pipe R P to nearly the same level as the free surface in the supply tank, the whole will remain motionless or in a static condition. If we now depress the dash valve D V, and then let it go, the machine will immediately begin to work, and continue to work automatically without any attention or even oiling for years, until stopped by some accident or by the wearing out of one or both of the valves. Of course, the supply of water must be maintained, so that the drive pipe is always kept full. This pipe should not be throttled in any part, and the weight on the dash valve must be so carefully adjusted, that it will just overcome the internal pressure—*i.e.*, drop from its seat—and permit water to escape thereat. Then, the acceleration produced by gravity on the water coming down the drive pipe very soon produces a greater pressure on the dash valve than that due to the mere static pressure. This increased force suddenly raises it again to its seat, when the kinetic energy which has been imparted to the water lifts the check valve and forces some water into the air vessel. Whenever this kinetic energy has been spent, the compressed air in the air vessel, together with the weight of the check valve, causes it to close, and immediately thereafter the dash valve automatically opens. The same cycle of operations takes place over and over again, the air in the air vessel gets more and more compressed, and water rises higher and higher in the rising or delivery pipe, until it issues as a continuous stream from its mouth into the cistern or receiving tank. From this tank it may be drawn off at pleasure for all the various uses of a mansion-house or farm steading, &c.

The air vessel plays two important parts in each cycle of the operations of this interesting and useful apparatus. (1) The air contained therein acts as a cushion by minimising the water hammer action, which would otherwise stress the various parts, and tend to break the joints. (2) The air acts as a store of energy by taking up, during its compression, a part of the kinetic energy of the water, and then giving out the same gently, thus producing a constant flow of water through the delivery pipe. If the vertical height of the column of water in the rising pipe be about 34 feet above the check valve, the pressure per square inch on the upper surface of this valve will be one atmosphere, or, say, 15 lbs. on the square inch, and the air in the air vessel will be compressed to nearly that pressure,

and therefore occupy about half its original volume. If the column be 68 feet high in the delivery pipe, the pressure on the valve will be about 30 lbs. on the square inch, and the air in the air vessel will occupy one-third of its original volume, and so on. Hence, it is necessary to proportion the size of the air vessel to the vertical height through which the water has to be forced in the delivery pipe. Besides this, air becomes absorbed by water, and in a short time the air vessel, if small, would become entirely filled with water. The air vessel may, however, be kept charged with air in a very simple manner by the introduction of a snifter valve S V, screwed into the ram casing, immediately below the check valve. In its simplest, and probably its most efficient form, it consists of a brass plug with a very small hole drilled through its axis. Every time that water is forced through the check valve a very small quantity also passes through this tiny opening in the snifter valve; and each time that the check valve is forced down upon its seat a rebound or reaction of the water takes place, and produces a partial vacuum immediately underneath the check valve. Consequently, a little air is forced into this vacuum by the atmospheric pressure, and this air is carried up into the air vessel at the next stroke or pulsation, thus keeping up the necessary supply for effecting a continuous flow of water into the receiving tank. If everything about this machine is thoroughly tight and in good working order, and the valves are made of the best proportions and weights, an efficiency of from 80 to 90 per cent. can be obtained therefrom, and it has been found possible to work it with a minimum driving head of only three feet. The several causes for loss of efficiency are:—

(1) Eddies caused by the sudden stoppage of the water's motion.

(2) The friction of the water passing along the drive pipe D P, and the casing of the apparatus.

(3) The weight and friction of the dash valve D V, which has to be lifted at each stroke or pulsation.

(4) The weight and friction of the check valve C V, which has also to be lifted at each stroke.

(5) The slip of the check valve C V—*i.e.*, a slight quantity of water may slip back past this valve when in the act of closing.

(6) The friction of the water passing along the rising pipe R P.

(7) Any defects of tightness in the faces of the dash and check valves.

The sudden closing of the dash valve is only necessary to prevent the water spending a large portion of its energy in friction

at the restricted orifice while it is closing. Large rams are now made with special valves to stop the water gradually without throttling it, and so avoid the shocks caused by sudden closing without losing anything in efficiency.*

EXAMPLE I.—If 1,000 lbs. of water pass per minute through the drive pipe under a head of 6 feet, and 60 lbs. of water are delivered into the receiving tank, which is 87 feet above the check valve, what is the efficiency?

$$\text{Efficiency} = \frac{\text{work got out}}{\text{work put in}} \text{ (in the same time).}$$

$$\therefore \quad \text{Efficiency} = \frac{87 \times 60}{6 \times 1000} = \cdot 87$$

Or, **Efficiency = 87 per cent.**

If the length of the drive and rising pipes be considerable, and if there be many bends and much throttling of the passages, then the efficiency will thereby be reduced to a considerable extent. By a simple modification of the ram shown in the illustration, river or impure water may be made to raise spring or pure water; the two waters are separated by a diaphragm, and the pumping action actuates two valves, the one being a suction and the other a delivery valve.

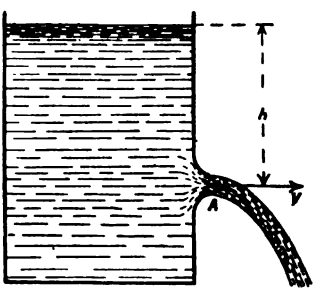

EFFLUX OF WATER FROM A CIRCULAR ORIFICE.

Velocity of Efflux and Flow of Water from a Tank.—Consider a jet of water issuing from a small circular orifice A at a depth h below the free surface of the water in the tank. If we take the datum line at the orifice, then inside the vessel, where the water is still, the energy is entirely potential and equal to $m g h$; whereas, it is all kinetic just outside the opening and amounts to $\frac{1}{2} m v^2$.

Hence, $\frac{1}{2} m v^2 = m g h$; or, $v^2 = 2 g h$;

i.e., $$v = \sqrt{2 g h}. \quad \text{(VI)}$$

It will be observed from this equation (VI) that the velocity

* See § 30 of Gordon Blaine's *Hydraulic Machinery* for an illustrated description of Mr. H. D. Pearsall's improved hydraulic ram.

v is the same as that attained by a body in falling freely from a height h; and further, that it would be the same even if the water had no free surface, so long as the pressure at the level of the orifice was equal to that due to a head h.

If there be a loss of head f due to friction and eddies formed by the water in passing through the orifice,

Then, $\frac{1}{2} m v^2 = m g (h - f)$; or, $v = \sqrt{2 g (h - f)}$. (VII)

If, a = The cross area of the orifice in square feet.
r = „ radius of the orifice in feet.
v = „ average velocity of the water in feet per second.
h = „ head of the water in feet.
g = „ acceleration due to gravity or 32·2 feet per second per second.
And Q = „ quantity of water flowing out from the orifice in cubic feet per second.

We find from equations (V) and (VI) that :—

$$Q = a v = a \sqrt{2 g h} \text{ cubic feet per second.}$$

This formula is very nearly true for a small tapered opening, but with a flat one, as shown in the next figure, the cross area of the

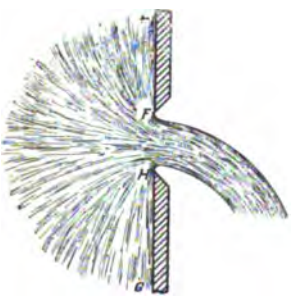

EFFLUX OF WATER FROM A VERTICAL FLAT ORIFICE.

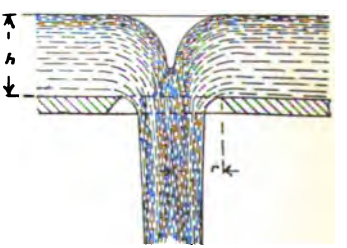

EFFLUX OF WATER FROM A HORIZONTAL FLAT ORIFICE.*

stream where the stream lines are parallel, at a short distance outside the opening, is less than that of the orifice. The ratio of these two areas is called the *coefficient of contraction*, and it is found experimentally for a flat opening to be 0·64. The contraction is caused by the water flowing along the inner flat surfaces E F and G H and then leaving them at a tangent. It has also been found by experiment that for a sharp-edged orifice the velocity v is only

* By mistake the figure has been drawn with a vortex, but when measuring water we must prevent the formation of a vortex by putting in radial blades.

$0{\cdot}97\sqrt{2gh}$. Hence, the actual flow for *a small circular orifice* will be:—

$$Q = 0{\cdot}64\,a \times 0{\cdot}97\sqrt{2gh} = 0{\cdot}62\,a\sqrt{2gh}$$

$$\therefore \quad Q = 0{\cdot}62\,\pi r^2\sqrt{2gh} \text{ cubic feet per second.} \qquad \text{(VIII)}$$

In measuring a small flow of water by this method, it is run into a tank having a carefully made clean cut orifice of known area, until the surface level is just sufficiently above the outflow to cause the water to run out as fast as it runs into the tank. This difference of level, or head h, is measured and the above formula applied.

Accurate results cannot be obtained from a large circular opening placed in the side of a tank, because the parts of it would have different depths from the free surface, and consequently the water would have different velocities at these parts. If we, however, put the orifice in the bottom of the tank, as shown in the right-hand figure, then the velocity will be approximately the same at all parts of the opening, and we can enlarge it so as to measure a much greater flow of water.

Measurement of a Flowing Stream.—In order to ascertain the available power from a stream or river, as well as to test the efficiency of a hydraulic installation, it is of the first importance to determine the rate of flow—*i.e.*, the number of cubic feet or gallons of water passing a given point per unit of time. At first sight, this would appear to be a very simple matter; but, as will be shown, it is not so easy to do so with accuracy, for several special precautions have to be observed and constants obtained.

Rectangular Gauge Notch.—When we have to measure large quantities of moving water, then such orifices as we have previously dealt with are quite unsuitable. In such cases, it is usual to pass the whole of the water over a special form of weir or gauge notch. This consists of a board placed across the stream between stakes and carefully puddled, so that all the water must flow over it. The top bevelled edge of this board must be well above the surface of the water on the delivery side. The length of the notch is usually less than the width of the stream, and the board should be continued from each end in a straight line (as shown in the perspective view) so as to give definite conditions; or parallel guides may be placed in the stream before the gauge board. In the former case, the inflow of water at the ends of the notch board causes end contraction, while in the latter, this effect is avoided. In each case, contraction of the stream is caused by the water flowing upwards from E to F, as shown by the sectional figure a few pages further on. Further, the surface directly over the notch board is

lower than that of the still water in the pond above the board. If, however, we neglect these effects we see that with different lengths



PERSPECTIVE VIEW OF A RECTANGULAR GAUGE NOTCH.

of notch board the total flow will be proportional to its length. Now, consider any horizontal strip of the cross section of the stream over the notch (say, one-thousandth of its total depth); then, if we increase the depth of the stream over the notch, the vertical width of this strip and consequently its area will be proportionally increased, as well as its depth below the free surface of the water. But the velocity of the water passing through this strip varies as the square root of its depth, and the quantity as the area multiplied by the velocity. This result will hold good for each elementary strip, and will, therefore, apply to the whole stream.

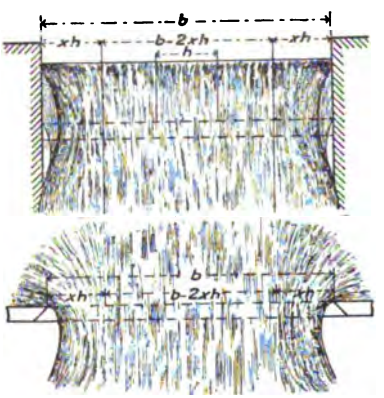

FRONT VIEW AND PLAN OF A RECTANGULAR GAUGE NOTCH.

Hence, $Q \propto a\,v \propto h \times \sqrt{h} \propto h^{\frac{3}{2}}$ for different depths;

And, $Q \propto b$ for different breadths of stream at the notch;

$\therefore$ $Q = k\,b\,h^{\frac{3}{2}}$ for a rectangular notch. . . . . (IX)

Here, k is a *coefficient of discharge* which must be found by experiment. This equation, however, would not give us accurate results if the proportions of the stream passing the notch were much different from that used to determine the constant k. With a very long shallow notch a considerable error will arise from the fact, that the water may adhere to the horizontal bevelled edge, and with a very deep narrow notch a similar effect would be produced by the bevelled sides. The above formula is often used and is quite correct for similar streams; but if the flow is variable, the depth will change with the flow of the water while the breadth remains constant, so that the proportions of the stream obtained with different flows in a gauge notch of this kind are not the same.

The late Professor James Thomson showed how we may obtain a formula which will apply to all ordinary proportions of rectangular notches. In the central part of the stream the lines of flow are practically parallel and unaffected by the sides of the notch. Consequently, the water passing through this part will be proportional to its breadth. Suppose the influence of each end to extend perceptibly to a distance $x\,h$ from it. Then the breadth of the central part will be $b - 2\,x\,h$. Consider a portion of this central part whose breadth is equal to h. This will be a square and therefore similar for different sizes of stream. Hence, since the area is proportional to h^2 and the velocity to $\sqrt{h}$, the flow through this square will be:—

$$k_1 \times h^2 \sqrt{h} \text{ or } k_1\,h^{\frac{5}{2}}$$

where k_1 is a constant.

Consequently, the flow through the whole of the central part $(b - 2\,x\,h)$ will be:—

$$\frac{b - 2\,x\,h}{h}\,k_1\,h^{\frac{5}{2}} = k_1\,(b - 2\,x\,h)\,h^{\frac{3}{2}}.$$

If we now imagine the two side portions to be placed together, we will get another stream which will be of similar form whatever its actual size may be; for, it will always be a rectangle of depth h and length $2\,x\,h$. Consequently the flow through this will be:—

$$k_2 \times 2\,x\,h \times h^{\frac{3}{2}} = 2\,k_2\,x\,h^{\frac{5}{2}}$$

where k_2 is another constant.

Hence, the flow of the whole stream will be :—

$$Q = k_1 (b - 2\,x\,h)\,h^{\frac{3}{2}} + 2\,k_2\,x\,h^{\frac{5}{2}}$$

$$\therefore \qquad Q = k_1 \left\{ b - \frac{2\,x\,(k_1 - k_2)}{k_1}\,h \right\} h^{\frac{3}{2}}.$$

If we write c for $\frac{x\,(k_1 - k_2)}{k_1}$ which is a constant, we get:—

$$Q = k_1 \{b - 2\,c\,h\}\,h^{\frac{3}{2}}. \quad . \quad . \quad . \quad . \quad . \quad (X)$$

If one of the sides of the stream had a guide board we should have had x throughout instead of $2\,x$, and therefore $c\,h$ in our final results instead of $2\,c\,h$. If both sides of the stream be guided, this term would disappear and we would get the former result.

Mr. Francis, an American engineer, deduced the following empirical formula from a large number of experiments which he made :—

$$Q = 3{\cdot}33 \left(b - \frac{1}{10}\,n\,h\right) h^{\frac{3}{2}} \text{ cubic feet per second.} \qquad (X_a)$$

Here n is the number of end contractions (viz., 2, 1, or 0, as explained above), and the units employed are feet and seconds. It should be noted that this equation is of the same form as the previous one, and that neither is applicable to a notch whose length is less than $2\,x\,h$.

Thomson's Triangular Notch.—Professor James Thomson proposed and us d a gauge notch in the form of a right-angled isosceles triangle with its sides equally inclined to the vertical. It has the advantage of giving a similar form of stream whatever may be the size of the notch or the height of the water passing through it, and is, therefore, more accurate for measuring variable streams. As, however, less water is passed for a given height than with the rectangular notch, it is not so convenient for large flows; but by cutting a number of such notches, side by side like the teeth of a saw, considerable quantities of water may be dealt with.

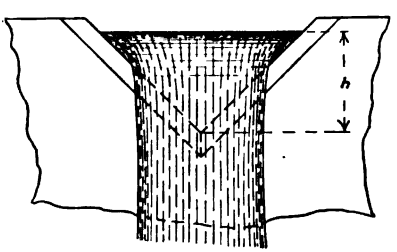

THOMSON'S TRIANGULAR GAUGE NOTCH.

If we consider corresponding elements of two such notches, we see that their areas are proportional to the square of their depths,

whilst, as before, the velocities of the water are as the square roots of the depths. Hence, the flow through a V notch will be :—

$$Q = k \times h^2 \times \sqrt{h} = k\,h^{\frac{5}{2}} \text{ cubic feet per second.} \qquad \text{(XI)}$$

In this case, the *coefficient of discharge k*, has been found by careful experiment to be 2·64.

Measurement of Head.—When using either of the previously mentioned notches for determining the flow of a stream or river we must ascertain the head h, with great accuracy. This may be done by aid of a level, straight edge, graduated staff, and a bent wire or hook-gauge in the following manner :—

Drive the vertical stake V S, into the bed of the stream at a position above the notch where the surface has no appreciable velocity. To obtain such a position the pond above the weir should not be too small. Level a straight edge S E, by the level L, with its lower edge resting on the inner edge F, of the bevelled board and on the point of the hook-gauge. Note the position R_1 on V S, opposite a mark M, on the longer limb H G. This gives us once for all the zero from which to reckon h.

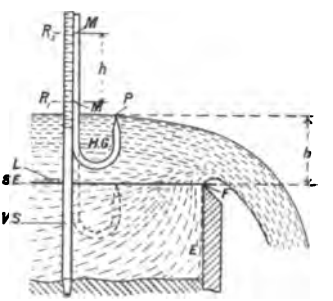

APPARATUS FOR MEASURING HEAD OF WATER.

When the water is flowing in the normal condition for making the test, raise H G until the point P just touches the surface of the water and note the reading R_2 on V S opposite M, as shown by the full outlined hook in the figure. The difference between this reading and the former one gives the head h.

As may be seen from the previous formulæ any mistake made in determining h will produce a larger percentage error in the result with the V and rectangular notches than with an orifice in the bottom of a tank. The latter is, therefore, preferred where great accuracy is desired and the quantity of water is not too large, such as when measuring the circulating water used by a steam engine.

Measurement of Large Streams.—When it is inconvenient or impracticable to place a weir gauge in a river, then the flow may be estimated by measuring the cross section a, of the river and finding its mean velocity v, at that section :—

Then, as before, $\qquad Q = a\,v.$

To do this, a number of equidistant points are marked along a rope which is then stretched across the river at right angles to the direction of the current. By means of a graduated pole the depth at each of these points is ascertained from a boat. The results are then plotted to scale and give us a cross section of the river and an estimate of its sectional area. The surface velocity at midstream may be roughly found by noting the time taken for a float to move a given distance down stream, and the *mean* velocity may be taken as 0·65 of this. It is, however, much more accurate to ascertain the velocity at a number of points of the section by means of a current meter and then calculate the mean value. The following illustration shows a current meter

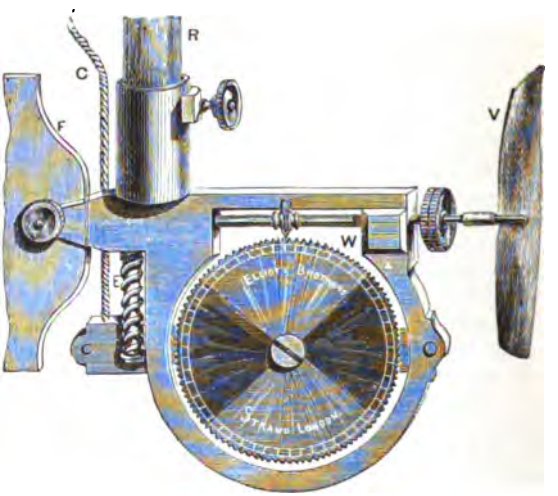

ELLIOTT'S CURRENT METER.

made for this purpose by Messrs. Elliott Brothers, London. It has a screw-shaped vane V, which is rotated by the water flowing past it. The revolutions of this vane are counted by the wheel W, which is driven by a worm on the same spindle as the vane. When the apparatus is immersed by means of the rod R to the required depth, with the vane pointing up stream, the cord C is pulled up and kept tight for a definite interval of time. This cord is attached to the end of a lever which carries the bearings of the counting wheel and is pushed down by a spring E. The wheel only gears with the worm when the cord is pulled, and the reading gives the number of revolutions of the vane from which the velo-

city of the water may be deduced. F is a rudder to keep the apparatus pointing directly upstream.

Horse-Power of a Stream.—After having obtained the quantity of water flowing in a stream, we have only to measure the available head in order to find its horse-power H.P. The head may be measured in feet by aid of a surveyor's level and staff. Then, if w be the weight of a cubic foot of water, and W the weight of the total flow of water per second, we get :—

$$Q = a\,v. \quad \text{And } W = Q\,w.$$

$$\text{Hence,} \quad \text{H.P.} = \frac{\text{ft.-lbs. per second}}{550} = \frac{h \times Q\,w}{550}.$$

$$\therefore \qquad \text{H.P.} = \frac{62{\cdot}5}{550} \times h\,Q = 0{\cdot}114\,h\,Q = 0{\cdot}114\,h\,a\,v. \qquad \text{(XII)}$$

Vortex Motion.—A whirling mass of fluid is termed a *vortex* and may be either *forced* or *free*. A *free vortex* is one which can be formed naturally, as when water flows through a hole at the bottom of a basin, and is such, that the energy of the fluid per unit mass is the same at all points in it. A *forced vortex* can only be produced artificially, and in it the energy of the fluid is different at different places. Such a vortex may be obtained by rotating a cup containing water.

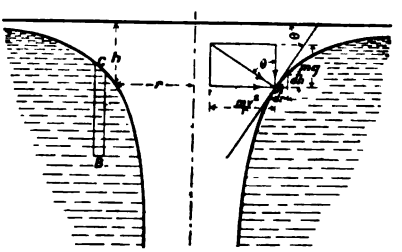

FREE VORTEX.

Free Vortex.—From the above condition of constant energy, the velocity at a point A, on the surface of the vortex and at a depth h below the level of the still water, must be the same as that due to a body falling freely from a height h.

$$\therefore \qquad v = \sqrt{2\,g\,h}.$$

A particle on the surface of the vortex is acted upon vertically by its own weight $m\,g$, and horizontally by a centrifugal force $\frac{m\,v^2}{r}$. The resultant of these two forces must make an angle θ, with the vertical, so that :—

$$\tan\theta = \frac{\frac{m\,v^2}{r}}{m\,g} = \frac{v^2}{g\,r} = \frac{2\,h}{r}.$$

Here m is the mass of the particle and r the radius of the circle in which it revolves.

This resultant must also be perpendicular to the surface of the fluid at A, since the fluid cannot resist any shearing component. Consequently, if the slope of the surface at A be $\tan\theta$,

$$-\frac{d\,h}{d\,r} = \tan\theta = \frac{2\,h}{r}.$$

Or, $$\frac{d\,h}{2\,h} = -\frac{d\,r}{r},$$

i.e., $$\tfrac{1}{2}\log h = -\log r + \log c,$$

$\therefore$ $$\log\sqrt{h} = \log\frac{c}{r},$$

$\therefore$ $$h = \frac{c^2}{r^2} \quad . \quad . \quad . \quad . \quad . \quad . \quad . \quad . \quad . \quad \text{(XIII)}$$

Here, c is a constant of integration which will depend on the size of the vortex. It is the radius of the vortex at unit depth.

Since the total energy is the same at all places in the fluid and the pressure at B due to the column B C, just makes up for the lower level of B, the velocity in any thin vertical tube of fluid such as B C must be constant and equal to that at the surface of the tube.

A vortex of this kind was applied to centrifugal pumps with radial blades by Professor James Thomson in order to convert, as far as possible, the kinetic energy of the water into potential energy. The vortex commences at the circumference of the wheel and the radial component of the water's motion is outward.

Forced Vortex.—In a vortex whose angular velocity ω is constant throughout, we have at any point A on the surface :—

$$\text{Centrifugal force} = m\,r\,\omega^2,$$

$\therefore$ $$\tan\theta = \frac{m\,r\,\omega^2}{m\,g} = \frac{r\,\omega^2}{g}.$$

$\therefore$ $$\frac{d\,h}{d\,r} = \frac{\omega^2}{g}\,r.$$

Or, $$d\,h = \frac{\omega^2}{g}\,r\,d\,r.$$

$\therefore$ $$h = \frac{\omega^2\,r^2}{2\,g} = \frac{v^2}{2\,g}. \quad . \quad . \quad . \quad . \quad . \quad . \quad \text{(XIV)}$$

This is the equation to a parabola with its axis vertical, and, therefore, the surface of the vortex will be the paraboloid formed by rotating this parabola about its axis. The velocity of any particle D, on the surface of the vortex is that which would be attained by a body falling a distance equal to D C. The kinetic and potential energies are both least at the centre B, and become greater as we move upwards or outwards. We have a vortex of this kind in the wheel of a centrifugal pump with radial blades.

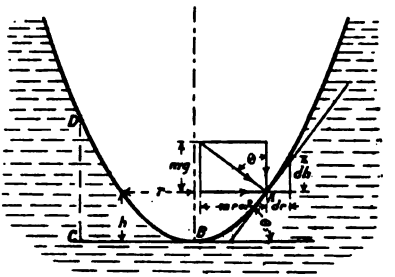

FORCED VORTEX.

Pressure due to Centrifugal Force.—When a liquid is rotating, its pressure is not the same for all points on one level. Thus, in the previous figure the pressure at B is atmospheric, while at the point C on the same level, the pressure is, in addition, that due to the head C D.



WHIRLING COLUMN.

Consider a uniform column of liquid B C, rotating round the axis B F, with an angular velocity ω and cross section a. Then, if ρ be the density of the liquid, the centrifugal force due to a small element of length dr, at a distance r from the axis is :—

$$\rho\, a\, dr \times \omega^2 r.$$

$\therefore$ The total centrifugal force of the column B C $= \rho\, a\, \omega^2 \int r\, dr$.

This force is spread over an area a, at the end C, and we must divide it by this area to get p, the pressure per unit area. If the whole column from B to C is full of liquid :—

$$\text{Then,} \qquad p = \rho\, \omega^2 \int_0^{r_1} r\, dr = \tfrac{1}{2} \rho\, \omega^2 r_1^2 = \tfrac{1}{2} \rho\, v_1^2 . \quad . \quad . \quad \text{(XV)}$$

But, if the part of the column from B to E is empty :—

$$\text{Then,} \qquad p = \rho\, \omega^2 \int_{r_2}^{r_1} r\, dr = \tfrac{1}{2} \rho\, \omega^2 (r_1^2 - r_2^2). \quad . \quad . \quad \text{(XV}_a\text{)}$$

Students who are not acquainted with the integral calculus will understand the following proof of these equations.

The centre of gravity of B C is at a distance of $\frac{1}{2}$ B C from B.

$$\therefore \text{ Centrifugal force due to the whole column B C } = \rho a r_1 \times \omega^2 \frac{r_1}{2} = \tfrac{1}{2} \rho a \omega^2 r_1^2.$$

The centre of gravity of the part E C is distant $\frac{r_1 + r_2}{2}$ from B.

$$\therefore \text{ Centrifugal force due to E C } = \rho a (r_1 - r_2) \omega^2 \frac{r_1 + r_2}{2}$$

$$\text{,, } \qquad \text{,, } \qquad = \tfrac{1}{2} \rho a \omega^2 (r_1^2 - r_2^2).$$

This formula may be applied to finding the equation for the forced vortex. For, in the figure of the *forced vortex*, if B C $= r$, and C D $= h$, then, $p = h w = h \rho g$.

Therefore, from equation (XV), we get :—

$$h \rho g = \tfrac{1}{2} \rho v^2,$$

Or,
$$h = \frac{v^2}{2g} \text{ (as before).}$$

Reaction of a Jet.—In general, when a fluid issues from an orifice it exerts a force on the vessel which contained it. This force is the reaction of the jet, and is due to the momentum given to the escaping fluid.

Let v = Velocity of efflux.
,, w = Weight of unit volume of the fluid.
,, W = Weight of fluid issuing per second.
,, m = Mass issuing per second.
,, Q = Quantity or volume issuing per second.
,, F = Force exerted on the vessel containing the fluid.

Then, the momentum given to the water per second $= m v$. And, since force is the rate of change of momentum :—

$$F = m v = \frac{W}{g} v.$$

But, $\quad W = w Q = w a v.$

$$\therefore \qquad F = \frac{W}{g} v = \frac{w a v^2}{g} = \frac{w a \,.\, 2 g h}{g} = 2 w a h. \quad \text{(XVI)}$$

This formula also gives the force acting on a vane of a turbine or waterwheel which alters the direction of flow of the water, and

in that case, v is the change of velocity produced by the vane. In applying the formula to any particular case, v is the total change of velocity produced until the water is quite clear of the vessel, and the direction of the force acting on the vessel is exactly opposite to that of v. The following figures will explain the results in three cases :—

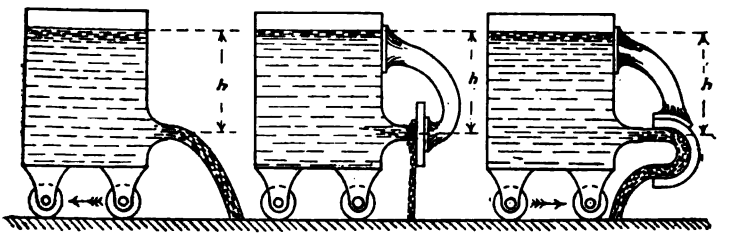

BACKWARD. NO MOTION. FORWARD.

MOTION PRODUCED BY A JET.

In the left-hand figure the jet of liquid issues towards the right and urges the containing vessel to the left. The jet in the central figure strikes a plate fixed to the tank close to it, and then drops vertically downwards; consequently, the water receives no horizontal momentum and the tank no motion from it. The water will, however, exert a pressure on the plate, and this pressure balances the force produced by issuing from the orifice. In the remaining figure the jet is turned backwards by a curved guide attached to the tank and the whole momentum imparted to the water is backwards, consequently the tank is pressed forwards. If there be no loss from friction or eddies, the backward velocity of the stream, when the tank is at rest, must be the same as that with which it left the orifice. The blade has not only stopped the water, but has given it an equal backward momentum, and must, therefore, be pressed with a force twice as great as the flat one in the previous case. The force on it, is therefore, 2 F or $4\,w\,a\,h$, which is four times the pressure on a plug stopping the orifice. When the tank is in motion, the momentum given to the water is modified thereby, as will be explained in connection with the Pelton wheel in the next Lecture. Steam life-boats are now frequently propelled by jets of water instead of by screw propellers.

As this reaction astonishes everyone who hears of it for the first time, we will consider it from another point of view. Water under a pressure of 100 lbs. per square inch issues out of a nozzle of 1 square inch in area, and impinges on a fixed vane of

such a shape as to gradually deflect the water and turn it back in the opposite direction, without loss by friction, and consequently without loss of velocity. Thus, the vane may be a double U, as in the Pelton wheel; or a semicircle; or it may deflect the water in more than one plane. Then, the pressure on the vane is 400 lbs., although the statical pressure on a plug or valve stopping the jet is only 100 lbs. Although it requires very little elementary dynamics to prove this fact, the statement is generally received with incredulity.

In the first place, it will be seen that the vane not only arrests the water—that is, imparts a negative acceleration to it, equal and opposite to what it received from the nozzle—but accelerates it equally in the opposite direction. Therefore, the total pressure on the vane is double the reaction on the nozzle.

The nozzle reaction at first sight appears to be 100 lbs.; that is, area of jet multiplied by pressure. But wait! Imagine a square vertical column in which water is maintained at a constant head. Near the bottom is a suitably formed horizontal nozzle closed by a plug. The system is then in equilibrium, since every square inch of wall has another square inch opposite to it which is acted on by an equal and opposite pressure. Opposite the nozzle, on the other side of the vessel, is a small circle equal to the area of the plug and equally pressed by the water. Now, remove the plug and let the water issue. It really does look as if the force pushing the vessel back was the pressure due to the head acting on this small circle on the back wall—that is, equal to the pressure multiplied by area of jet. But by Newton's second law, whenever we find a body moving at any velocity, we know the product of the force which has urged it and the time during which it has acted. Let us take a simple case and suppose the height of the water surface above the nozzle to be 16 feet. Then we know that the water issues as fast as if it had fallen 16 feet, and that its velocity is 32 feet per second. Consequently, every second a cylinder of water equal in section to the area of the jet and 32 feet long has a velocity of 32 feet per second impressed on it. Therefore, the urging force must be equal to its own weight; because when falling from rest by gravity—that is, when urged by its own weight—it acquires that velocity in one second. But the statical pressure is only half of this, being the weight of a cylinder of water equal in section to the jet and 16 feet long; and, since action and reaction are equal and opposite, the recoil of the vessel is equal to the force urging the jet, or twice the statical pressure.

Of course, if the jet strikes a flat vane at right angles the motion is stopped in its own direction, but not returned, and the pressure on the vane is twice the statical pressure. But, if the vane

returns the motion undiminished the pressure is four times the statical pressure.

Reduction of Pressure Round an Orifice.—Let h be the depth of a bell-shaped orifice and a its cross sectional area; then, if this orifice be completely closed by a flat plate, the force required to keep the plate in position will be $w\,a\,h$. It might therefore be supposed that, when the plate is removed and the water allowed to flow, this would be the force exerted on the vessel, but on looking at our former result (see equation XVI) we find that the actual force is twice as great, or $2\,w\,a\,h$. This difference is caused by a diminution of pressure on the surface round about the orifice. At these places the water has a certain velocity, and Bernouilli's theorem shows us that the pressure there must be less than when the liquid was at rest.

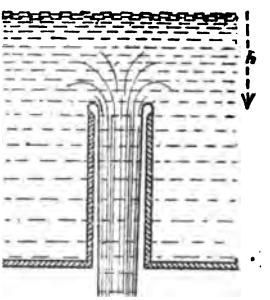

RE-ENTRANT ORIFICE.

There can be no reduction of pressure on the flat surface round the bottom of a re-entrant orifice, because there the water is practically at rest. The amount by which the pressure is reduced on opening the orifice must, therefore, be that on the area of the orifice itself, or $w\,a\,h$. Every second, this will set in motion a mass m as given by the equation :—

$$w\,a\,h = m\,v.$$

But,
$$m = \frac{W}{g} = \frac{w\,Q}{g} = \frac{w\,a'\,v}{g}.$$

Where a' is the cross area of the jet, and $v = \sqrt{2\,g\,h}$.

$$\therefore \qquad w\,a\,h = \frac{w\,a'\,v^2}{g} = \frac{w\,a' \times 2\,g\,h}{g}.$$

Hence,
$$a = 2\,a'. \quad . \quad . \quad . \quad . \quad . \quad . \quad . \quad . \quad . \quad \text{(XVII)}$$

That is, the area of the jet will only be half that of the orifice. This result has been found experimentally to be correct. With a sharp-edged orifice, such as we considered in the early part of this lecture, there is a certain reduction of pressure round the orifice, and, therefore, the contraction must be less than in this case.

Impact—Loss of Energy.—When a stream of fluid meets an obstruction which causes a sudden change in its motion, its kinetic energy is partially, or perhaps wholly, spent in forming eddies or

little whirls of water, and is thus lost so far as useful effects are concerned. The eddies are, however, soon stilled by the viscosity of the liquid and their energy is converted into heat.

Let us suppose a body of mass m_1 moving with a velocity v_1, to overtake and strike another body of mass m_2, and velocity v_2. After collision let the bodies move on together with a common velocity v.

Then, from the laws of momentum,

$$(m_1 + m_2)\, v = m_1 v_1 + m_2 v_2.$$

Or,
$$v = \frac{m_1 v_1 + m_2 v_2}{m_1 + m_2}.$$

But, before impact, the total energy was :—

$$E_1 = m_1 v_1^2 + m_2 v_2^2$$

And, after impact :—

$$E_2 = (m_1 + m_2)\, v^2.$$

$$\therefore \quad E_2 = (m_1 + m_2) \left\{ \frac{m_1 v_1 + m_2 v_2}{m_1 + m_2} \right\}^2 = \frac{(m_1 v_1 + m_2 v_2)^2}{m_1 + m_2}.$$

The energy lost is :—

$$E_1 - E_2 = \frac{(m_1 v_1^2 + m_2 v_2^2)(m_1 + m_2) - (m_1 v_1 + m_2 v_2)^2}{m_1 + m_2}$$

$$\therefore \quad E_1 - E_2 = \frac{m_1 m_2 (v_1^2 + v_2^2 - 2 v_1 v_2)}{m_1 + m_2} = \frac{m_1 m_2}{m_1 + m_2} (v_1 - v_2)^2. \quad \text{(XVIII)}$$

This lost energy is converted into heat. If one or both of the bodies be fluids the lost energy at first shows itself in eddies; but, as already explained, it is ultimately converted into heat. We thus see that when two streams moving at different velocities mix together, energy is lost and this loss is greater the greater the difference of the velocities. A similar effect takes place when water flows through a pipe with sudden changes of area, and even to a slight extent when the area is gradually varied, and also when water is flowing in a pipe or channel above a certain speed. In all these cases, different parts of the water move with

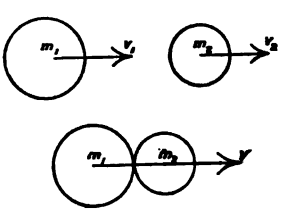

COLLISION.

different velocities, and these parts get mixed with one another. It also shows, why a turbine or water-wheel in which the water collides with the vanes, must have a low efficiency.

Resistance of a Pipe.—When a fluid is passing through a pipe it rubs against the sides and experiences a certain resistance to its motion. This resistance limits the flow in a long pipe and causes a loss of head or pressure. Had the water no viscosity its flow would not be affected by the friction of the inner surface; because, this friction could only act on the thin layer of water actually in contact with the pipe.

Professor Reynolds found that the manner in which water flows depends upon its velocity. When this is below a certain critical point the flow depends chiefly on the viscosity and is along smooth stream lines. On passing the critical velocity, the water no longer moves steadily, but breaks up into numberless little whirls or eddies which move along with it, and absorb energy from the main stream. The former condition may be called *Steady Flow* and the latter *Eddy Flow*. This was beautifully demonstrated by Professor Reynolds by passing water from a large tank through a glass tube and then injecting a fine stream of coloured liquid with the same velocity into the centre of the stream. The water in the tank was quite steady and entered the tube through a bell mouth. At low velocities the coloured liquid formed a thin line along the centre of the tube, but at a certain velocity it was seen to suddenly spread out through a considerable part of the water, and on photographing it by means of an electric spark it was found to be all twisted into little whirls.

RESISTANCE OF SMOOTH LEAD PIPE AT DIFFERENT SPEEDS OF A FLUID.

He also found, that the law connecting the resistance R, with the velocity v, was different for these two conditions. For the lower speeds he ascertained that the resistance was proportional to the velocity, but at greater speeds it varied as some higher power, ranging from 1·7 to 2 depending on the roughness of the pipe. Near the critical velocity, which depends on the diameter of the pipe and on the temperature, the law is uncertain. The temperature affects the viscosity on which the critical velocity also depends.

On plotting the logarithms of his results as obtained with a smooth lead pipe $\frac{1}{2}$ inch in diameter, we get the lines shown in the accompanying figure. This consists of two straight lines joined by a

curve of indefinite shape. The two straight parts have slopes of 1 and 1·72, showing that in one case the increase of log R is equal to the corresponding increment of log v, whereas beyond a certain point it is 1·72 times the corresponding increment of log v.

This shows us, that if c_1, c_2, and c_3 be constants, then :—

$$\text{For steady flow, } R = c_1 v.$$

$$\text{For eddy flow, } R = c_2 v^{1\cdot 72} + c_3.$$

The resistance of the pipe for any velocity is most conveniently expressed in terms of the difference of pressure per unit length required to force the necessary quantity of liquid per second through it when level. This is called the *Slope of Pressure.* Whether the pipe is level or not, if it be of uniform bore, this slope is given by the difference of level between the free surfaces of the pressure columns at any two points, divided by the length of pipe between them. This has been termed the *Slope of Free Level,* and is shown graphically by a line passing through the surfaces of a series of little pressure columns.

Hydraulic Mean Depth.—The resistance of a pipe or channel is directly proportional to the extent of the wetted surface in a given

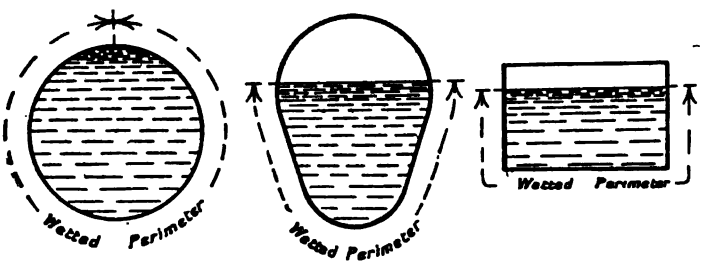

WETTED PERIMETER OF DIFFERENT SECTIONS.

length, and inversely to the cross area of the stream. The transverse length of the whole surface wetted by the stream is called the *Wetted Perimeter,* and the ratio of the cross area of the stream to its wetted perimeter is termed the *Hydraulic Mean Depth,* which we shall denote by D.

The friction of the pipe or channel will consequently vary inversely as the hydraulic mean depth.

Combining this with the former results we have for water pipes or channels :—

$$R = c \frac{v^n}{D}. \quad . \quad . \quad . \quad . \quad . \quad . \quad . \quad \text{(XIX)}$$

Where c is a constant depending on the nature of the surface and the temperature of the water, and n is a number varying from 1·7 for smooth lead pipes to 2 for very rough pipes. The critical velocity for water in ordinary pipes is so low, that in all practical cases in which we wish to know the resistance, the actual velocity is always above it.

For a circular pipe, whose diameter is d, and which is full of running water, the wetted perimeter is the circumference of the circle :—

$$\therefore \qquad D = \frac{\frac{\pi}{4} d^2}{\pi d} = \frac{d}{4} \text{ for a circular pipe.} \quad . \quad . \quad (XX)$$

For a rectangular open stream of depth h and breadth b, the wetted perimeter $= 2h + b$ and the area is $b\,h$:—

$$\therefore \qquad D = \frac{b\,h}{2h + b} \text{ for an open rectangle.} \quad . \quad . \quad (XXI)$$

LECTURE XXXV.—QUESTIONS.

1. Prove the law for changing p, v, and h along a stream line in a frictionless fluid. Apply the law to find the funnel shape of the surface of water in a basin from which the water is flowing by a central hole. (S. & A. Hons. Exam., Part I., 1898.)

2. Prove the law for changing p, v, and h along the stream lines in a frictionless fluid. Apply, neglecting change of level, to the case of adiabatic flow of air from one vessel to another through a small orifice, and deduce the rule for maximum quantity flowing. (S. & A. Hons. Exam., Part. II., 1898.)

3. Describe the action of a jet pump, or of a good form of injector.

4. Water flows through a round sharp-edged orifice 3 inches in diameter in a flat plate, at about 12 inches below still-water level. Show by a sketch your notion of the shapes of the stream lines. If we wish to know the pressure at any point, why is it not sufficient to know only the depth? (S. & A. Adv. Exam., 1898.)

5. Deduce a formula giving the velocity with which water issues from an orifice, and show how to apply it to water under pressure.

6. Discuss briefly the relative advantages under various circumstances of the different methods of measuring a stream of water.

7. Find the horse-power of a waterfall 70 feet high, when the stream is such that it passes over a gauge notch 6 feet long with a head of 15 inches. If it is employed to drive a turbine of 80 per cent. efficiency, what B.H.P. would you expect to obtain?

8. Investigate the form of the surface of water which flows out of a hole in the bottom of a basin with a vortex motion.

9. What is meant by a constrained vortex, and why will such a vortex rapidly disappear when left to itself? Find the form taken by the surface and show how to apply this to finding the pressure in a centrifugal pump.

10. The wheel of a centrifugal pump 2 feet outside diameter has a very large case and rotates at 100 revolutions per minute about a vertical axis, and almost no water is being delivered. Calculate and show in a curve the pressure at points in a horizontal plane, at various distances from the axis. The vanes are bent backwards at an angle of 30° with the radius at the outer part; if the radial flow becomes 2 feet per second and the circumferential openings are 200 sq. inches in area, what is the kinetic energy of the water leaving the wheel? What is the pressure in excess of that at the inner rim of the wheel where the water enters without shock? If there is no frictional loss to what height will the water be lifted above the well? In an actual pump with small wheel case what is the probable lift? (S. & A. Hons. Exam., Part II., 1898.)

11. "Barker's mill" consists of a horizontal pipe with a nozzle at right angles to it at each end thus 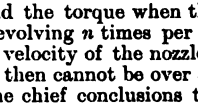 Water enters it by a vertical pipe at the centre, and the whole is so mounted that it can rotate about the axis of this pipe. Find the torque when the water is issuing under a head h, and the mill is revolving n times per minute. Show that the power is greatest when the velocity of the nozzles is half that due to the head, and that the efficiency then cannot be over 50 per cent.

12. What are the chief conclusions to be drawn from Reynold's experiments on the flow of water through pipes?

13. What is meant by the *Hydraulic Mean Depth* of a pipe or channel, and show how we use it in calculating the resistance to the flow of water?

LECTURE XXXVI.

WATER-WHEELS AND TURBINES.

CONTENTS.—Hydraulic Motors—Overshot Water-wheel—Breast-wheels—Undershot Water-wheel—Fairbairn's Improvements—Clack Mill—Pelton Wheel—Turbines—Girard Turbine—Jonval Turbine—Günther's Governor — Thomson's Vortex Turbine — Little Giant Turbine—Centrifugal Pumps and Fans—Questions.

Hydraulic Motors.*—In connection with hydrostatics we have already described some machines for obtaining motion by hydraulic

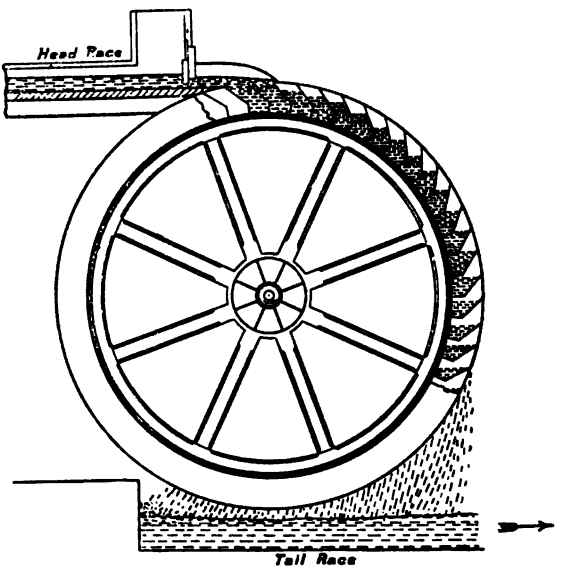

OVERSHOT WATER-WHEEL.

means, but in all these cases the water acts solely by its pressure,

* Students should refer to *Hydraulic Motors* by G. R. Bodmer (London, Whittaker & Co.), and to *Hydraulic Machinery* by R. Gordon Blaine (London, E. & F. N. Spon, Limited) for further information on the design of water-wheels and turbines.

We now come to the consideration of other water motors in which the weight and momentum of the water are also employed. These may be divided roughly into two classes—Water-wheels, in which the water acts for the most part directly by its weight; and turbines, in which it acts by its momentum. We cannot, however, draw a very sharp line between them, as they gradually merge into one another, and the power of both ultimately depends on gravity.



OVERSHOT WATER-WHEEL BY MESSRS. WHITMORE & BINYON.

Overshot Water-wheel.—This consists of a wooden or iron frame to which is fixed a number of blades, so as to form with the inner circumference a series of buckets for holding water. The water is led along an aqueduct termed the *head race* to the top of the wheel, and there enters the buckets. Its weight forces them downwards and thus makes the wheel revolve. As each bucket in turn approaches its lowest position the water gradually drops out of it into the tail race. The motion of the water as it enters the wheel also assists to some extent in producing rotation. The buckets are so shaped and fixed to the wheel, that as little as possible of the available power shall be lost by the water spilling from them before they reach the tail race. The sectional view shows one form of bucket for this purpose whilst the outside view shows another with curved blades. One disadvantage of this wheel is, that the water leaves

it with a velocity opposite in direction to that of the tail race, if this flows the same way as the head race. The water therefore does not get away so freely from the tail race, and more clearance is necessary at the bottom of the wheel which thereby involves a loss of head.

Breast-wheels.—This last consideration, coupled with the difficulty of supporting the head race for large overshot wheels, has brought about the introduction of breast-wheels, in which the water is introduced between the top and middle of the wheel as shown by the next illustration. The breast-wheel is also frequently made with curved blades into which the water drops almost vertically, and then acts chiefly by its weight. The motion of the

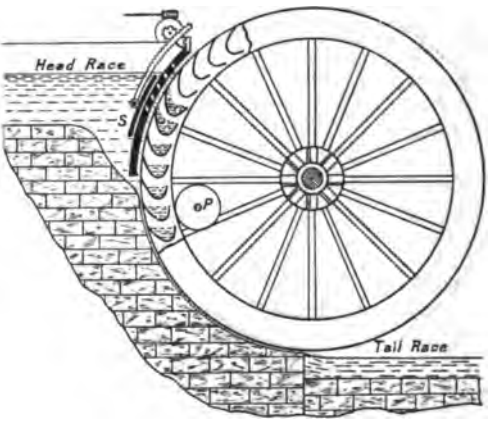

FAIRBAIRN'S BREAST-WHEEL.

wheel in this case assists the escape of the tail water instead of hindering it as in the previous one. The curved ventilated form of bucket with closed breast, as shown in the above figure, was first introduced by Sir William Fairbairn and greatly increased the efficiency of the motor. But, for small wheels, such as are used for farms, where first cost is more important than efficiency, hey are usually made radial as shown by the following figure.

Here, the water is allowed to attain a certain amount of motion before reaching the wheel, and therefore acts partly by momentum and partly by its weight. The buckets have no ends, but the wooden breast serves to keep the water from escaping by the sides and circumference of the wheel before it reaches the bottom.

Breast-wheels into which the water enters near the top are called high breast-wheels.

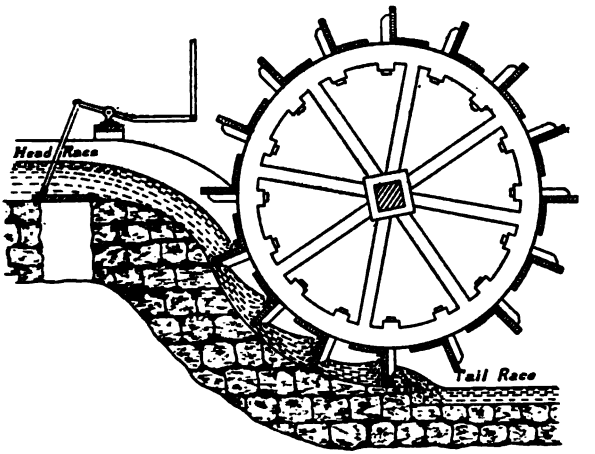

BREAST-WHEEL WITH RADIAL BLADES AS USED IN COUNTRY FARMS.

Undershot Water-wheel.—The breast-wheel just described forms a connecting link between water-wheels proper and turbines, to

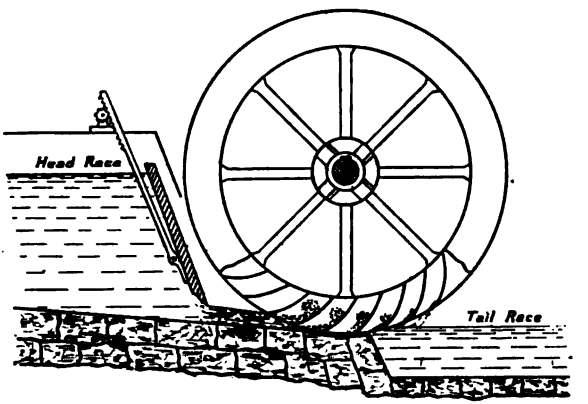

UNDERSHOT WATER-WHEEL.

which latter class undershot wheels really belong. With an undershot wheel the whole energy of the water is allowed to become kinetic and then it acts on the blades solely by its momentum. Here,

again, radial blades are common, but they are very inefficient on account of the large loss due to the eddies which are caused by the impact of the water upon them, and from the kinetic energy which the water still possesses on leaving the wheel.

In order that the water may be applied without shock and to avoid the formation of eddies, the tips of the blades should be so inclined as to be parallel to the motion of the water relatively to the wheel at its point of entering. To find this direction, draw A B to represent the velocity of the water as it leaves the head race, and A C the circumferential velocity of the wheel at the point where the water enters it. Then, by completing the triangle A B C we find C B the direction of the tip of the blade at A. The blade is curved upwards, and the position where the water leaves it is at the same level as where it enters, in order that the water may drop out with as little kinetic energy as possible.

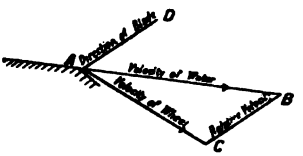

ANGLE OF BLADE.

Fairbairn's Improvements.—In the illustration of Fairbairn's breast-wheel, we have shown the regulating sluice S connected by a curved rack and pinion to the worm gear which is turned by a hand-wheel, until the sluice admits the desired quantity of water to develop the necessary power. In the case of large wheels which have to drive textile or other machinery requiring great uniformity of speed, this worm gear is connected to a ball governor which automatically adjusts the position of the regulating sluice, to suit the different demands of the works.

In addition to other improvements effected by Fairbairn, we may mention, that instead of driving from a spur-wheel keyed to the water-wheel shaft, he bolted a segmental annular toothed wheel directly to one of its outer sides or flanges and geared it with a pinion as shown at P. He thus diminished the distance between the plummer block bearings of the water-wheel shaft, relieved its radial arms from conveying the driving stresses, and at once obtained the necessary speed without intermediate gearing. The importance of this improvement was so self-evident to mill-owners, that many large wheels which had previously given considerable trouble and shown signs of distress, were fitted with Fairbairn's drive, and are working to the present day at full power with perfect regularity and freedom from breakdowns.

We may here summarise Fairbairn's improvements in water-wheels, viz. :—(1) The use of iron instead of wood in their construction, thus lightening and at the same time strengthening the various parts.

(2) The adoption of curved ventilated iron buckets instead of straight wooden ones, to prevent eddies and thus obtain a greater efficiency from the head and body of water.

(3) The introduction of a closed breast to prevent the escape of the water during its turning of the wheel.

(4) Driving directly from the sides and periphery of the water-wheel in order to minimise the stresses in the arms, reduce the distance between the bearings, and at once obtain the desired speed.

The Clack Mill.—One of the oldest forms of water-wheels, and one which belongs to the same class as the undershot wheel, is



THE OLD CLACK MILL.

that known as the "clack mill." It is supposed to be of Norwegian origin, and was certainly introduced therefrom into the Orkney and Shetland Islands several hundred years ago. Our illustration is reduced from a sketch made by Mr. Sellar in 1898 of the only remaining working clack mill in Orkney, at the farm of Millbrig, in the parish of Birsay. The owner, Mr. Folster, says that it has been handed down to him from generation to generation for more than two hundred years.

The water under a head of 10 feet enters by the left-hand aperture and leaves by the right-hand one. During its passage the water impinges upon the further side of the wooden radial arms which are fixed to the vertical iron shaft. The lower end of this shaft rests in a conical footstep, whilst the upper end carries the revolving millstone, and is steadied by a bearing immediately beneath the lower or fixed stone. The corn to be ground is fed into a "head" or "harp" H, and as the upper stone revolves the projecting wooden pin P, strikes the radial arm A connected to the lower end of H. This shoggles a portion of the grain into the central opening at each revolution. In doing so, a clacking noise is made by this pin striking the outstanding arm, which has given rise to the local term of "clack mill." The grain is carried down by gravity and finds its way into groves between the two stones where it is ground into rough meal. This compound of meal and husk dribbles from the shoot S into a wooden bin, from which it is removed, and separated by shaking and blowing, or by another machine, for future use in the shape of porridge or oat-cake.

Pelton Wheel.—The previous examples naturally lead us to the consideration of the Pelton wheel, which is very often used for



PELTON WATER-WHEEL BY MESSRS. W. GÜNTHER & SONS, OLDHAM.

great pressures and high falls. As will readily be understood from a consideration of the accompanying figure, this form of water-wheel consists of a plain disc mounted upon a central shaft, and carrying a number of curved buckets fixed at equal distances around its periphery. A conical nozzle attached to the supply pipe is so fixed as to direct a jet of water upon each of these buckets in turn and thus drive the wheel at a high speed. The

buckets have a central division, and as they curve outward towards each side, the jet is thereby deflected in two portions and then backwards. With properly designed buckets, and when the circumferential velocity of the wheel is half that of the jet, the water will simply leave the buckets with little or no remaining kinetic energy, and hence the efficiency of such a wheel may be very great. Pelton wheels are used for falls having a head of from 30 to 2,000 feet, or for corresponding pressures derived from water-pumps and city hydraulic power mains. They are sometimes made with several nozzles, each being fitted with a stop-valve, so that the power can be varied by shutting off the water from one or more of them. When there is only one jet, the power can be varied without a change of efficiency by simply unscrewing the nozzle and putting on another of a different size. If the power is varied by partially closing the stop valve, we lose a large amount of energy in friction at the valve, and the efficiency is thereby considerably reduced.

We may find the efficiency of a Pelton wheel, on the assumption that there are no eddies or friction, as follows :—

Let V = The velocity of the water as it issues from the nozzle.
" v = " " vane.

Then, $V - v$ is the relative velocity of water on vane, which is not changed as it moves around the vane. Therefore, the final velocity of the water is $v - (V - v)$ or $2v - V$, which may be either positive or negative. Now, by the principle of conservation of energy, the initial energy of the water is equal to that spent on the vane + the final energy. Therefore, the efficiency of the wheel is :—

$$\eta = \frac{\textit{Power got out}}{\textit{Power put in}} = \frac{\textit{Initial kinetic energy - final kinetic energy}}{\textit{Initial kinetic energy}}$$

$$= \frac{V^2 - (2v - V)^2}{V^2} = \frac{4\,v\,(V - v)}{V^2}.$$

This is evidently greatest, and equal to unity, when $2v - V$ is zero, or $V = 2v$, since $(2v - V)^2$ can never be negative. That is, for maximum efficiency the speed of the wheel should be half that of the water, and when it runs either quicker or slower than this the efficiency will be less. For example, if the speed of the jet is 100 feet per second and the vanes travel 20 feet per second, the theoretical maximum efficiency is :—

$$\eta = \frac{4 \times 20(100 - 20)}{100 \times 100} = 0{\cdot}64 \text{ or } 64 \text{ per cent.}$$

The above are ideal cases in which the water is directed backward by the vane parallel to its original direction. In practice, the Pelton vanes do not quite do this, but are slightly divergent, as shown, in order that the water may clear the following vane.



VANES FOR PELTON WHEEL.

The final velocity of the water is easily found by the parallelogram of velocities, thus—Draw A B the velocity of the water and A C that of the vane. Then, A D is the final velocity of the water, and the kinetic energy carried away is proportional to A D^2.

We have seen, in the preceding Lecture, that when the ideal vane is stationary, the pressure on it is four times the statical pressure on the area of the jet. At maximum efficiency, when the relative velocity of the water and vane is half what it is when the vane is stationary, the force on the vane is equal to this statical pressure, because the impact varies as the square of the relative velocity. Or,

Water striking vane per second $= \frac{w}{g} a (V - v)$ *lbs.*

Change of velocity produced by vane $= 2 (V - v)$.

$\therefore$ Momentum imparted per second $= \frac{w}{g} a (V - v) \times 2 (V - v)$.

Or, Force of jet on vane . . . . $= \frac{2 w a}{g} (V - v)^2$.

And, when, $v = \frac{1}{2} V = \frac{1}{2} \sqrt{2 g h}$,

Then, $F = \frac{2 w a}{g} (\frac{1}{2} \sqrt{2 g h})^2 = w a h.$

Hence, in this case, the power expended on the vane is $F \times \frac{1}{2} v$. But, the total power of the jet is $F \times v$, or twice as much. This would make the efficiency to be one half, but we have proved it to be unity. Where is the discrepancy?

Suppose a single vane to move away indefinitely in a straight line in the direction of the jet, it will be seen that there is an ever-increasing quantity of water flying through the air after the

vane. This represents an ever-increasing debt of uncollected kinetic energy, so that only half the water issuing per second strikes the vane in the same time.

But now, let E be the initial position of the vane (see previous figure), and E F the distance it travels in one second. When it has arrived at F, let another vane be suddenly interposed at E. There is now a rod of water between E and F running twice as fast as the vanes, and the last particle of this water will only overtake F when it arrives at G and the second vane at F. A third vane is now interposed at E and the process repeated.

This is what happens in the Pelton and other impact wheels, such as the Laval steam turbine. The fluid strikes two vanes at once, one behind the other; a statement hard to believe unless approached by the above argument.

Turbines.—These form a type of water motor which occupy much less space, are more efficient, more easily governed, suit a greater range of fall, and generally run at a greater speed than ordinary water-wheels. They are classified in several different ways according to the manner in which their special properties are considered. We shall first of all divide them into four classes, viz.—(1) inward flow; (2) outward flow; (3) parallel (or axial) flow; and (4) mixed flow turbines. In the first two kinds, the water either flows inwards from the outer circumference as in the Thomson turbine, or outwards from the inner circumference as in one type of the Girard. In the third class, it flows parallel to the axis, entering at one side of the wheel and leaving at the other as in the Jonval. The fourth type has both radial and axial flow, and the water usually enters at the circumference and leaves at one or both sides parallel to the axis.

In the second place, we find all of the previous types divided into what are termed *drowned* and *ventilated* turbines. The former are designed to run quite full of water and may be submerged in the tail race, or used with a suction pipe; whilst the latter have ducts to admit air at atmospheric pressure into the wheel, and, consequently, cannot be submerged or used with such a pipe. The energy of the water entering the drowned type is partially potential and partially kinetic, whilst it is wholly kinetic before it enters a ventilated turbine. Hence, these two kinds of motors are sometimes respectively called *reaction* and *impulse* turbines.

The purpose of a suction pipe is to allow the turbine to be placed some distance above the tail race without losing the corresponding head. This suction pipe is merely an air-tight conduit to carry away the used water and must have its lower end below the surface of the tail race; moreover, it must not exceed 20 feet or thereby in vertical height from the turbine to the tail race; otherwise

the water column supported by the pressure of the atmosphere will be broken by the introduction of air into the exhaust conduit.

A disadvantage of most turbines of the "drowned" type is, that in regulating its speed and power we cannot gradually cut off the water without a considerable drop in efficiency. We can, however, do so in several steps when divisions are placed in the wheel for this purpose. This is because the guide passages to the wheel must always be quite full of water, which would not be the case if the opening to any particular guide port was only partially closed.

Girard Turbine.—This wheel is named after the French engineer M. Girard, who in 1856 first designed the ventilated and impulse turbine. It can be made with either a vertical or horizontal axis and for both axial and outward flow. The former is used for low falls of from 6 feet and upwards, and the latter for high falls up to 1,000 feet.

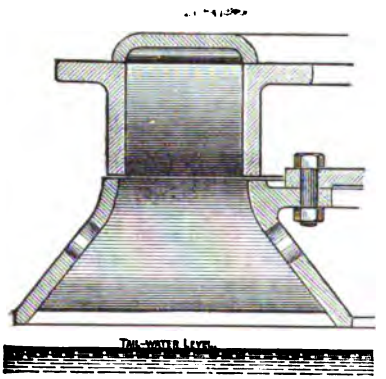

RADIAL SECTION. GÜNTHER'S AXIAL FLOW GIRARD TURBINE.

By referring to the two accompanying figures, which represent radial and circumferential sections of this turbine, it will be seen that the gate for controlling the water supply is placed above the guide ports A, C, through which the water passes and issues with full velocity due to its

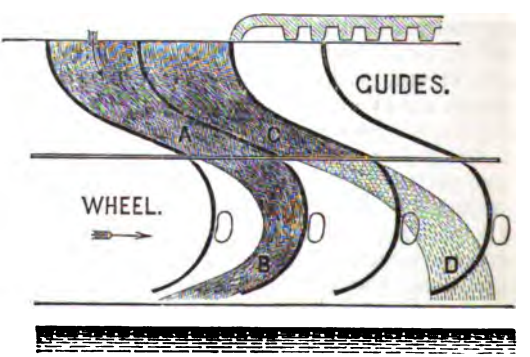

CIRCUMFERENTIAL SECTION. GÜNTHER'S AXIAL FLOW GIRARD TURBINE.



GIRARD TURBINE FOR LOW FALLS BY MESSRS. W. GUNTHER & SONS, OLDHAM.

head. It then glides along the concave surfaces of the wheel buckets B, but does not quite fill them. The inclination of the upper edges of the buckets is obtained in the manner explained,



GÜNTHER'S GIRARD TURBINE FOR LOW FALLS.

for undershot wheels, while that of the lower edges is made as small as possible in order that the water may not leave the vanes with much kinetic energy. To allow of this inclination being smaller than would otherwise be the case, the sides of the wheel are splayed outwards as shown by the radial section in order that the water may spread and not foul the convex surface of the next blade. The path of the water relatively to the moving wheel is shown at B, whereas, the dotted lines through D show the actual motion of the stream as seen from a fixed point. The ventilating holes are clearly shown in both views. These

GÜNTHER'S GIRARD TURBINE FOR LOW FALLS.



GÜNTHER'S GIRARD TURBINE FOR HIGH FALLS.

admit air to the wheel and prevent the formation of eddies in the empty parts.

The above left-hand illustration is that of a complete turbine, and the two full-page illustrations show how they are fixed in position ready for work. The second of these also indicates how the governor is attached.

When used for high falls the water is only admitted to a few of the buckets at a time. It is then usually made with outward

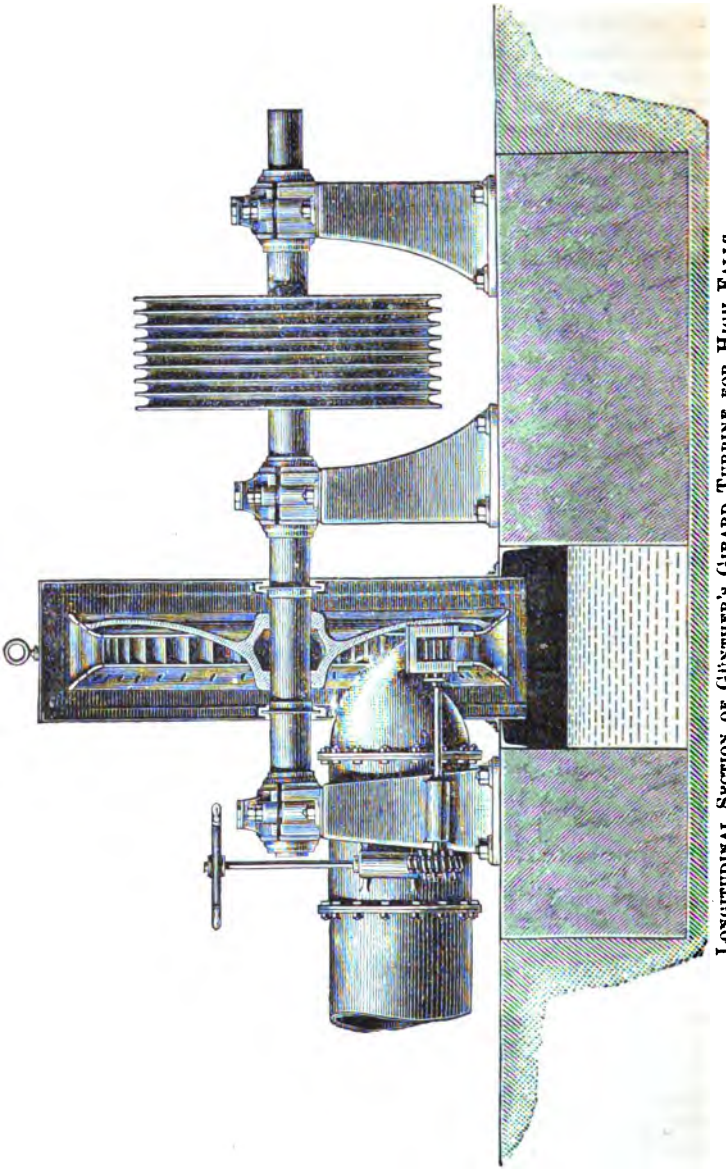

LONGITUDINAL SECTION OF GÜNTHER'S GIRARD TURBINE FOR HIGH FALLS.

flow, and mounted on a horizontal axis as illustrated by the sectional drawing facing this and the right-hand figure on the previous page. The pipe for admitting the water and the hand gear for adjusting the flow are clearly visible, whilst a grooved pulley for rope driving is placed on the right. This type of turbine gives a high efficiency at medium as well as at full load.

Jonval Turbine.—This turbine is of the parallel or axial flow type and is designed to be always kept full of water. The accompanying figures give radial and circumferential sections, having the same lettering as the corresponding figures for the Girard turbine. It is usually employed for low and medium falls of from 2 to 40 feet, and can run equally well when completely submerged or when connected to a suction pipe. The adjustment of the water supply is effected by means of a slide or slides which close the guide passages one after another. A turbine of this type has the greatest efficiency when all its passages are full of water, and consequently the size of the wheel depends on the quantity of water to be passed in a given

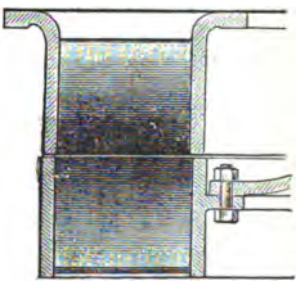

RADIAL SECTION. GÜNTHER'S JONVAL TURBINE.



CIRCUMFERENTIAL SECTION. GÜNTHER'S JONVAL TURBINE.

time. The reason why this class of turbine is not used for small power with high falls is, that very little water would be required, and, therefore, the dimensions of the wheel would be very small —perhaps impracticably small—whilst the speed of rotation would be very great. With the Girard type on the other hand, the efficiency is not reduced by having only one or two of the

buckets in use at one time. We can, therefore, employ as large a wheel as we like, and only use the requisite number of buckets for the required power. This enables us to get a slower speed of rotation which is usually desirable. The Girard type, however, cannot work with a suction tube, and only works well when clear of the tail water. An inch or two of fall, must, therefore, be sacrificed, and this reduces the efficiency with low falls.

Günther's Turbine Governor.—For many purposes the motion of a turbine is so regular that no automatic control is required, but for some classes of machinery a self-acting governor is desirable. The accompanying figure shows the one made by Messrs. Günther & Sons, of Oldham, for this purpose. It consists of an ordinary



GÜNTHER'S TURBINE GOVERNOR.

Watt governor (see Lecture XXIII.) which can shift a belt from a loose pulley to either of two fast pulleys connected by bevel gearing to the pillar for adjusting the turbine. At the normal speed the belt is on the loose pulley, but any change of speed causes the belt to be shifted and the vertical shaft is turned more or less in one way or the other according to the required quantity of water. The governor is driven from a belt on the turbine, or by some shaft from it, and can be disconnected from the hand gear by merely freeing a clutch.

Thomson's Vortex Turbine.—Imagine a wheel placed with its axis coinciding with that of the free vortex already considered in the

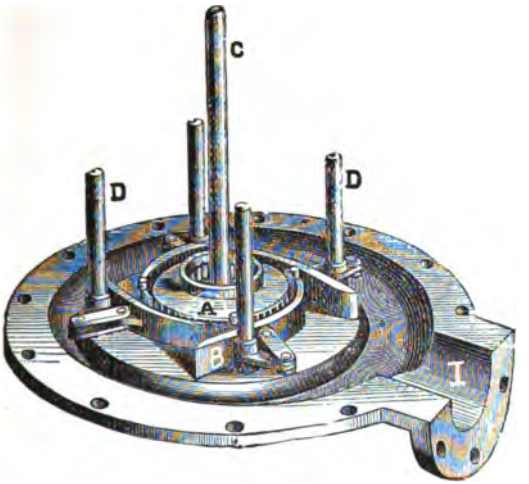

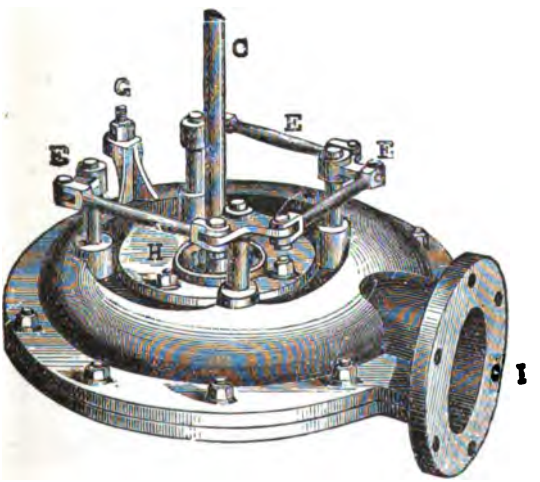

VORTEX TURBINE BY MESSRS. GILBERT GILKES & CO., LTD., KENDAL.

preceding lecture. This wheel will be carried round by the vortex, and if we arrange matters so that the water passes through the

wheel giving up its energy to it while fresh water takes its place, we have the essentials of Professor James Thomson's vortex turbine.

As will be seen from the foregoing illustrations, there are only four guides in the vortex, and by altering the inclination of these, we can adjust the radial component of the motion of the water and the amount of water flowing through the turbine. In the first figure the turbine is represented with its cover removed, and in the second with its case complete. A is the revolving wheel keyed to the shaft C. B is one of the guide blades connected by the bell cranks and shafts D to the outside rods E, which can be adjusted by a screw or by a governor. The shaft runs on a lignum vitæ pivot which is lubricated by the water.

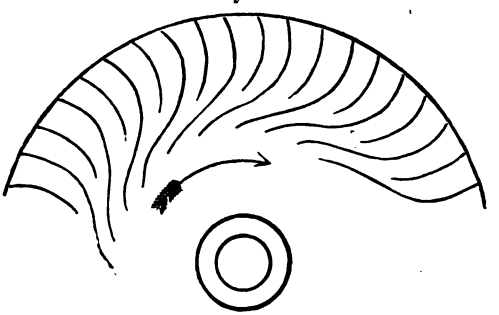

SECTION OF WHEEL OF VORTEX TURBINE.

On account of the constrained motion of the water inside the wheel it requires a large number of guides. For the purpose of reducing the friction and to lessen the loss of area due to the



SINGLE AND DOUBLE VORTEX WHEELS.

thickness of the guides, it will be seen from the above section that every second guide is only half the length of its neighbouring one. The wheel is made either single or double. In the latter case, it

has the same efficiency at half gate as at full gate, but being of the inward flow "drowned" type it will have a lower efficiency at other loads. Our next figure illustrates one of these turbines as fixed in position.

One great advantage of an inward flow turbine is that, to a certain extent, it is self-governing. When its velocity increases,



SINGLE VORTEX TURBINE BY GILBERT GILKES & CO., LTD., KENDAL.

so also does the centrifugal force which opposes and consequently reduces the inflow of the water; whilst the opposite action takes place when the turbine is being reduced below its normal speed.

Little Giant Turbine.—We now come to the fourth or mixed flow type of turbine, and as an example we have chosen the "Little Giant" turbine. As may be seen from the illustrations the water

enters at the circumference and passes out at the top and bottom and there is a sluice for regulating the supply. The passage has a division so that water can be entirely shut off from the upper half of the wheel.

The same firm also makes a special "flume" turbine—*i.e.*, one which is placed directly in the water in the same way as the



LITTLE GIANT TURBINE BY S. HOWES, LONDON.



WHEEL FOR LITTLE GIANT SPECIAL FLUME TURBINE.

single vortex turbine shown on the previous page. The sectional view shows a turbine formerly made with a wheel similar to that in the Little Giant Flume Turbine, but with a different casing. In this instance, the pivot for the wheel can be raised or lowered by a lever which is clamped in position by a nut. The wheel is held down by a fixed ring fitting in a groove on the wheel, just above the lower splayed-out part.

End View.

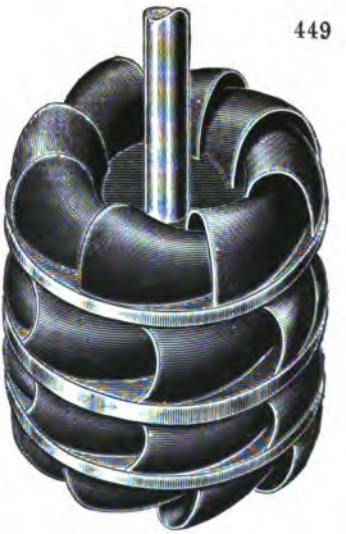

Side View.

Wheel for Little Giant Turbine.

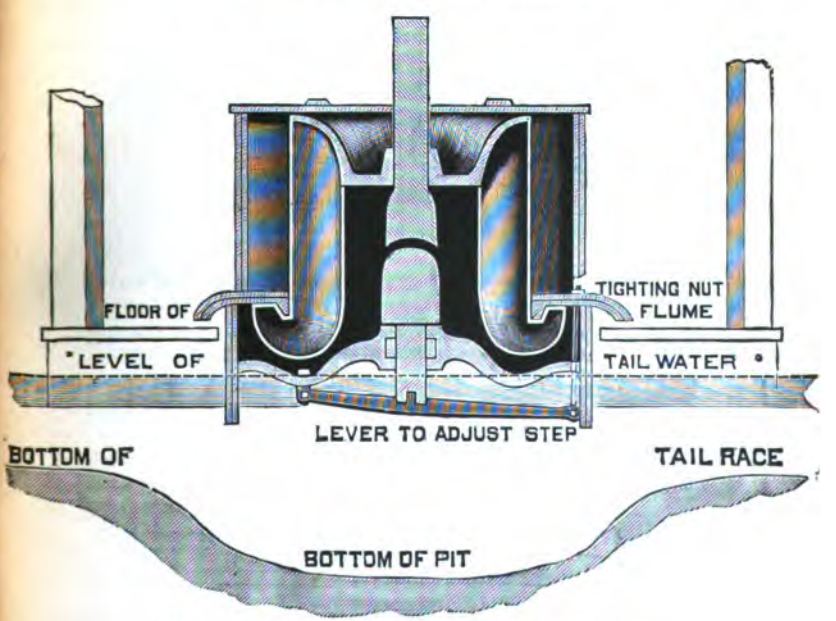

Vertical Section of the Little Giant Turbine.

Centrifugal Pumps and Fans.—If certain kinds of turbines be driven by a prime motor the centrifugal force of the fluid carried round with the wheel will cause the fluid to flow outwards in a continuous stream. If the fluid be water the machine is termed a *centrifugal pump;* whereas, if we are dealing with air, it is called a *fan.* Such machines are, therefore, merely reversed turbines; but, in order to get the best results, they must be specially designed, because the best design for a turbine is not by any means the most efficient and suitable for a pump or fan.

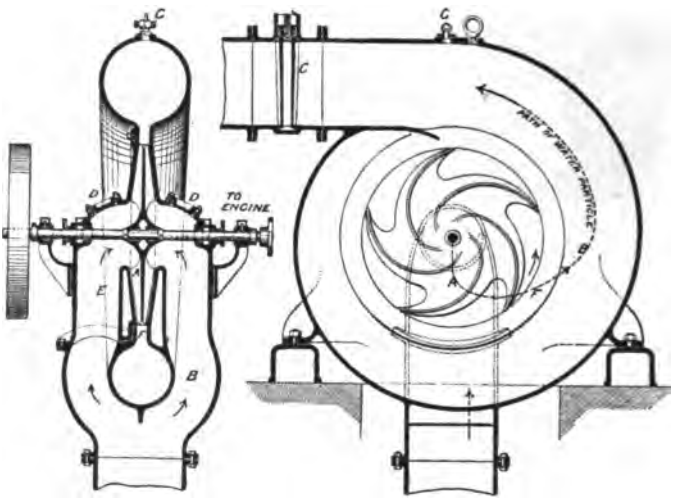

CENTRIFUGAL PUMP.

Centrifugal pumps are largely used whenever a quantity of water has to be elevated through a small height, such as in the case of emptying graving docks and sunken vessels, circulating the cooling water through condensers, or dredging sand, gravel, and mud from rivers, whilst centrifrugal fans are employed for ventilating mines, ships, and buildings, as well as for producing an artificial draught to smiths' fires, cupolas, and boiler furnaces, &c.

The illustration* shows a good form of centrifugal pump with curved blades. A is a wheel rotating inside a casing B, thus giving the water which enters at the centre a certain amount of kinetic and pressure energy. F is a small whirlpool chamber which,

* The above figure is reduced from one in Mr. Lineham's *Textbook on Mechanical Engineering* (London: Chapman Hall & Co.).

as already explained, allows the water to form a free vortex, and converts part of its kinetic energy into energy of pressure. The water moves in a free vortex in the volute-shaped pipe, the path of a partical being shown in the figure by a dotted line and arrows.

The difference of pressure produced by the pump depends upon the density of the fluid in the wheel as well as on the speed of rotation. Consequently, when there is only air in it, the pump is not able to produce a sufficient vacuum to make the water rise into it. In order to get over this difficulty, an ejector G, and a sluice C, are added. When the pump is to be started the sluice is closed and the air exhausted from the pump chamber by a jet of steam being passed through the ejector. The water then rises into the wheel and the sluice is gradually opened as the speed is increased. When the pump is fairly started the steam jet is shut off and the sluice fully opened. Sometimes a non-return valve is placed at the foot of the suction pipe to prevent the pump and pipe emptying when the wheel is stopped. In such a case, the pump is ready to start again at once.

Sometimes centrifugal pumps are made with radial blades. They then require a much larger whirlpool chamber to allow the kinetic energy to change into pressure energy without a serious loss in eddies.

LECTURE XXXVI.—QUESTIONS.

1. Sketch an undershot wheel. Explain why its efficiency is so low when it has radial blades, and show how the blades should be made to avoid this loss.

2. Water flows radially at 4 feet per second towards a part of a wheel of a centrifugal pump or turbine which is moving at 12 feet per second, find the angle of the vane that the water may enter without shock. If the vane were radial, at what angle ought the water to be guided so that it might enter without shock; its radial component of velocity being the same as before? (S. & A. Adv. Exam., 1898.)

3. Give outline sketches of the common types of water-wheel, and compare their relative advantage.

4. Distinguish between water-wheels and turbines, and explain the advantages of the latter.

5. Sketch the Pelton wheel and describe its action.

6. Sketch and describe a turbine of the Girard type, and mention its advantages and disadvantages.

7. Describe, with sketches, a Jonval turbine, and explain its relative advantages.

8. Sketch the wheel and case of an inward flow turbine for a fall of 50 feet; 8 cubic feet of water per second. Calculate the diameters and breadths of the wheel, the number of revolutions per minute, and the size of the shaft. (S. & A. Hons. Exam., 1897.)

LECTURE XXXVII.

REFRIGERATING MACHINERY.

CONTENTS.—Refrigeration—Preliminary Considerations—Carbon Dioxide as a Refrigerating Agent—Elementary Refrigerating Apparatus—Simple Refrigerating Machine—Carbon Dioxide Refrigerating Plant—Anhydrous Ammonia as a Refrigerating Agent—De La Vergne's Refrigerating Plant—De La Vergne's Double Acting Compressor—The Linde System of Refrigeration—Apparatus for Transmitting the cold produced to the Chambers requiring Refrigeration—Questions.

Refrigeration—Preliminary Considerations.—An interesting example of the conversion of heat into work is afforded by a refrigerating machine. The simplest form of machine consists of an air-compression pump driven by a steam engine, or other motive power, in which the pump is water jacketted and the air is cooled under pressure by being passed through a surface condenser where the water abstracts the sensible heat generated by the mechanical work of compression. The air thus cooled, but still under pressure, is conveyed to an air engine and allowed to perform work by expanding against some resistance. A large proportion of the work originally performed during the operation of compression is again given out, with a corresponding reduction in the air temperature. A machine on this principle may be conveniently constructed by arranging the steam, compression and expanding engines to work on one crank-shaft. The expanding air thus assists in the work of compression. After deducting the necessary losses due to cooling, leakage, &c., the work done in the expansion cylinder amounts to about 65 per cent. of the power absorbed by the compression cylinder; the remaining 35 per cent. being supplied by the steam or other prime mover. The air having thus given up its heat, exhausts from the expansion cylinder at a very low temperature, reaching in one authenticated instance as low as -124° F.

The large coal consumption of machines of this class has, however, led to their being superseded, in almost all cases, by machines in which a more direct conversion of heat into work takes place.

If we take any liquid and commence to vaporise it, we find that, it is necessary to maintain a continual application of heat in order to bring about this physical change. The amount of heat necessary to convert a unit weight of a liquid to a unit

weight of gas at the same pressure, is always constant for the same liquid. For example, 1 lb. of water at a temperature of 212° F. and at atmospheric pressure, requires the application of 966·6 British Thermal Units to convert it into 1 lb. of steam at the same temperature and pressure. Conversely, to condense 1 lb. of steam to 1 lb. of water, both being at 212° F. and 14·7 lbs. pressure per square inch, we must abstract from the steam 966·6 thermal units by contact with a cold body. This principle holds good for any liquid.

A refrigerating machine with steam as a working medium, would not be practicable unless the temperature of everything in connection with it was maintained above 212° F., but there are many liquids which have, when compared with water, a very low boiling point; notably ether, sulphurous acid, ammonia, carbon dioxide, and ethylene. Each of these has been employed for purposes of refrigeration with more or less success; and all of them depend on the same principle—viz., the absorption or the giving out of their latent heat in converting the liquid to a gas, or *vice versâ*.

It is not necessary here, to enter into a discussion as to the relative merits of different liquids as refrigerating agents, but in practice, anhydrous ammonia is the agent generally used, and in a lesser degree, carbon dioxide. The necessary machinery is of itself extremely simple, although the details afford scope for a great amount of elaboration and ingenuity.

Carbon Dioxide as a Refrigerating Agent.—Carbon dioxide or carbonic anhydride, which is commercially known as "carbonic acid," is a colourless gas, and quite without odour when pure. It is under all circumstances perfectly innocuous, and has practically no effect on animal tissues or other bodies. It will, however, produce asphyxiation in animals when present in the atmosphere in quantities exceeding 25 per cent. by excluding oxygen from the blood. This gas may be very readily liquefied, either by diminishing its temperature or by increasing its pressure. This fluid has a specific gravity of about ·8, and can only remain in the liquid state when under considerable pressure, the pressure varying with the temperature of the liquid.* The moment the pressure is removed, the heat present in surrounding bodies, at once assists in the evaporation of the liquid carbon dioxide and the bodies themselves are consequently left in a colder condition than before the evaporation took place.

Elementary Refrigerating Apparatus.—Let us consider for a moment an elementary piece of apparatus in which refrigeration

* Carbonic acid gas can only be liquefied by pressure when below 86° F. which is termed its critical temperature.

can take place. If we take two strong coils of piping and surround each with a vessel of water and then connect the two by means of a stop valve at their lower ends, as shown by the accompanying figure, we shall have a simple form of refrigerating machine. Suppose, that when the stop valve is closed, we charge the condenser coil with gas under liquefying pressure, by means of a force pump. The water surrounding the coil will absorb the heat which has been imparted to the gas by compression, and the condensed liquid will gradually accumulate at the bottom of the coil. On opening the stop valve, this liquid will run into the second or evaporating coil, and the pressure here being lower than is necessary for maintaining the liquid state of the material, evaporation will at once commence. The heat necessary for evaporating this liquid is

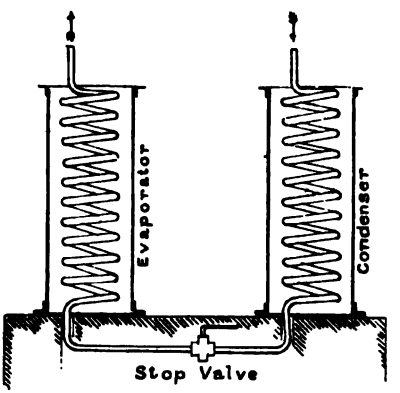

ELEMENTARY REFRIGERATING MACHINE.

absorbed from the water surrounding the evaporating coil, which will thereby become considerably reduced in temperature. To accomplish this result in practice three things are necessary:—(1) A compressor, to raise the pressure of the gas to whatever may be necessary for its liquefaction; (2) a surface condenser, to remove the heat generated by the mechanical work of compression; (3) an evaporating vessel, where the liquid may re-evaporate into a gas, and absorb heat in the operation.

Simple Refrigerating Machine.—The following figure of a simple refrigerating machine will explain the cycle of operations. C is a compressing pump delivering gas under pressure into the condensing coil C C, which consists of a strong worm of iron or copper piping immersed in a tank of water. R is a

regulating-stop valve having a fine adjustment. E is the evaporator which consists of a coil of piping similar to the condensing coils. It is also immersed in a tank containing the water or other fluid to be cooled. The regulator R is closed, as soon as the pressure in the condenser has risen to that at which liquefaction can take place and the gas commences to condense on the inner surface of the coil C C. The drops of liquid descend and accumulate in the lower portion of this coil. The regulator is then opened, with the result, that a small quantity of liquid escapes into the evaporator. Now, since the compressor draws its supply of gas from the evaporator, the pressure in the evaporator must be less than in the condenser. Consequently,

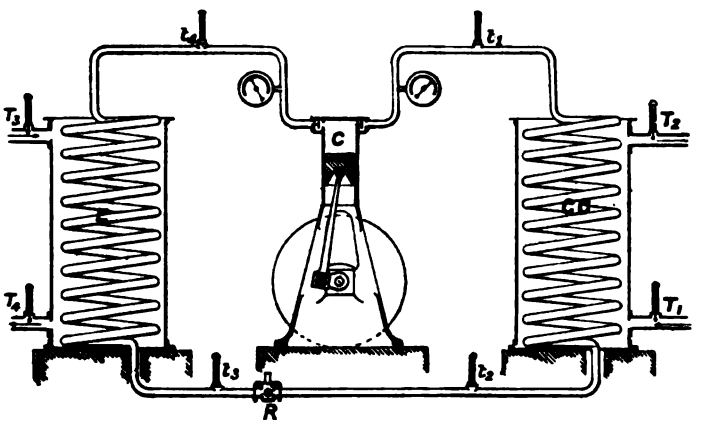

SECTIONAL DIAGRAM OF A SIMPLE REFRIGERATING MACHINE.

INDEX TO PARTS.

C for Compressor.	E for Evaporator.
C C ,, Condensing Coils.	t_1 to t_4 ,, Thermometers.
R ,, Regulating Valve.	T_1 to T_4 ,, Thermometers.

the liquid commences to boil, and absorbs heat for its transformation into a gas from the surrounding liquid. The temperature of this liquid is therefore naturally reduced by the operation. The liquid within the coil is entirely re-converted into a gas which ultimately finds its way to the compressor, and thus the cycle of operations is completed.

Suppose four thermometers be inserted into the pipes conveying the gas to and from the condenser and evaporator, as shown at t_1, t_2, t_3, t_4. It will be found that they do not register alike, for t_1 will show the highest temperature, then t_2 and t_3 will be

some degrees lower, and t_4 will be lowest of all. Suppose now, that the liquids in the vessels surrounding C C and E be caused to circulate in the direction of the arrows, and that thermometers T_1, T_2, T_3, T_4, be placed on each of the inlet and outlet pipes. It will be found, that the temperature of the incoming water T_1 is lower than T_2 the temperature of the water going out of the condenser; also, that T_3 the temperature of the liquid entering the evaporator, is *higher* than T_4 its temperature as it leaves this vessel. This shows, that with respect to the gas or liquid within the coils of the condenser or evaporator, heat is lost in the condenser and gained in the evaporator. The amount of the former is represented by the difference between T_1 and T_2 multiplied by the weight of water passed through the condenser in pounds, and the latter may be expressed in terms of the difference between T_3 and T_4 multiplied by the weight of the fluid passing through the evaporator, and by the specific heat of this fluid.

If we could construct an ideal machine, in which the liquefaction of the gas was automatic, it would be found that the loss of heat in the condenser, measured in thermal units, was exactly equal to the gain of heat in the evaporator. The sensible heat gained and lost by the fluids surrounding the coils in the condenser and evaporator respectively, would be the exact measure of the latent heat of the refrigerating medium, as abstracted in the condenser and returned in the evaporator. It is, however, necessary to change the physical condition of the gas between the evaporator and condenser, so that it can be liquefied in its passage through the latter vessel. Suppose that the pressures in both evaporator and condenser are the same and constant. In order to ensure condensation and liquefaction in the condenser, its temperature would have to be constantly maintained *below* that of the evaporator, a condition of things which is manifestly impracticable, since the evaporator is becoming colder with every repetition of the cycle of operations. This difficulty must therefore be met in another way. If we wish to liquefy any gas, it is necessary to bring its molecules closer together, and this can be accomplished either by *increasing* the pressure or by *decreasing* the temperature of the gas, or both. Now, since it is not in this case practicable to reduce the temperature, the only alternative is to raise the pressure by means of the pump already referred to, which draws the gas from the evaporator and delivers it at an increased pressure into the coils of the condenser. But in order to compress a gas, mechanical work must be performed upon it, and this work re-appears in the form of heat. The temperature of the gas after compression is

therefore considerably higher than it was at the lower pressure on leaving the evaporator. This heat, in addition to the heat imparted in the evaporator, has to be abstracted and carried away by the cooling action of the water of the condenser.

As stated at the beginning of this Lecture, if we convert a unit weight of any liquid into a gas, we require the addition of a definite amount of heat, and to reconvert this gas into a liquid we require the abstraction of the same amount of heat, the amount being constant for any one liquid at a constant pressure and temperature. All gases do not require the same expenditure of energy to raise them to the same pressure, because they vary in what may be called their compressibility, and some gases occupy a smaller volume than others after an equal amount of compression. Carbon dioxide, for example, according to Regnault, only requires about 75 per cent. of the work necessary to produce the same amount of compression, as air or hydrogen. We can, by experiment, readily determine the exact pressure at which liquefaction will take place at any temperature; and knowing this, the machine can be designed of suitable strength to withstand the necessary pressure.

Owing to the difference in the power required to increase the pressure of different gases, it follows that the amount of heat imparted during compression must with some gases be greater than with others. This fact is of great importance in the selection of a suitable gas, and particularly so if cooling water be scarce. But whatever gas be employed, the pressure necessary to liquefy it must always be increased to a greater or less extent as the temperature of the cooling water rises.

Having considered the principles upon which an evaporative refrigerating machine depends for its action, we are now in a position to examine into the actual question of the interchangeability of heat and work. We can moreover at once establish a coefficient of efficiency for any refrigerating material.

Let, L = Latent heat of evaporation of the refrigerating medium in B.T.U.

And, H = Heat imparted during compression in B.T.U.

It follows, from what has been said, that the coefficient of efficiency will be $L \div H$, and, neglecting external losses, wL will represent the heat abstracted in the evaporator, whilst $H + wL$ will equal the heat added to the cooling water of the condenser, where w, is the weight in lbs. of the gas entering the condenser in a given time. It is, of course, impossible that a machine could work under such ideal conditions as we have assumed, since there must always be the effect of the high or

low temperature of surrounding bodies to determine whether there will be a loss or gain of heat in one or other of the parts of the machine. For instance, it is almost certain that the evaporator will be colder than the atmosphere; in that case, no matter how carefully it may be insulated, there will be some conduction of heat and the net quantity of the heat abstracted from the liquid to be cooled can only be $(w\,L - x)$, where x, is the amount of heat derived from outside sources. The amount of heat imparted to the cooling water in the condenser will therefore be $H + w\,L \pm y$; where y, is the heat lost or gained in the condenser due to the difference in temperature between it and its surroundings.

There is still another correction to be made to the above formula. When, as is usual, the evaporator is maintained at a very low temperature, a certain amount of heat must be imparted to it by the refrigerating liquid itself, as it is entering the evaporator in a comparatively warm condition. Thus, supposing there be t degrees difference in temperature between the condenser and evaporator, a unit weight of the refrigerating liquid will as it were import into the evaporator $t\,s$ thermal units; where s is the specific heat of the liquid in question. Therefore, if W be the weight of refrigerating liquid passing into the evaporator in a given time, the heat abstracted in the evaporator will be represented by the expression:—

$$w\,L - x - W\,t\,s.$$

Of course, $W\,t\,s$ will not in practice amount to a great deal; but, as Professor Linde has pointed out, it must not be neglected in an exact calculation of the work performed by any refrigerating machine. If there be no leakage, then on the average W will be the same as w.

These formulæ cannot be applied with absolute certainty in practice, owing to the impossibility of making all the necessary corrections due to the gain or loss of heat in the various parts of the machine, and owing to the friction of the gas in constricted passages. But, with care, this gain and loss of heat can be very nearly accounted for in an ordinary machine, as manufactured for commercial purposes and working under the conditions of everyday practice.

Carbon Dioxide Refrigerating Plant.—One method of cooling buildings, &c., on a large scale, is to employ a strong brine obtained by dissolving sodium chloride or common salt in water. This brine is first cooled by passing it through the evaporator of a refrigerating machine, and then circulating it in pipes placed within the chambers which it is desired to cool.

In the accompanying figure all the essential parts are shown of a small refrigerating machine as manufactured by Messrs. J. & E. Hall, of Dartford, for cooling small provision stores, dairies, &c., where the pump may be conveniently driven by a belt. In larger machines, the evaporator is contained in a separate

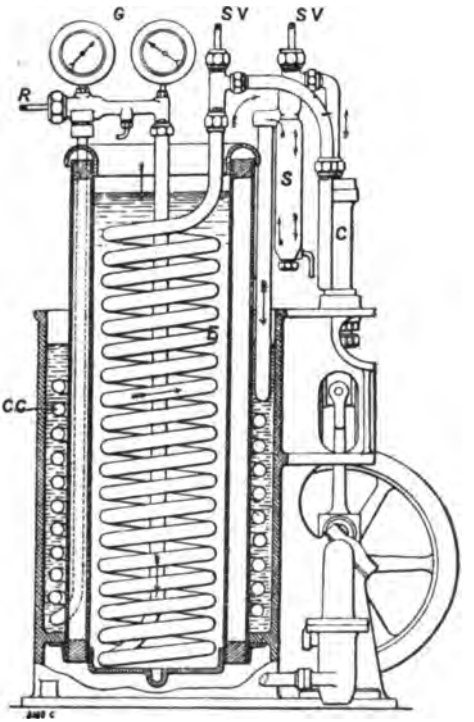

HALL'S CARBON DIOXIDE REFRIGERATING PLANT.

INDEX TO PARTS.

C for Compressor.	G for Gauges.
S ,, Separator.	E ,, Evaporator.
CC ,, Condensing Coils.	SV ,, Stop Valves.
R ,, Regulator.	

vessel and the compressor is driven by a compound- or triple-expansion engine; but, for the sake of compactness in this case, the evaporator is placed within its condenser, and the intervening space between them is carefully insulated by means of some non-conductor, such as hair felt or slagwool. The coils of

piping which form the condenser and evaporator are welded into continuous lengths and so connected that all joints shall occur in accessible positions. These and all the other gas joints are made by inserting copper rings turned from the solid metal between a pair of flanges or union coupling. This form of joint has been found very satisfactory. The condenser casing, Corliss frame and bearings for the compression pump, &c., are all made of cast iron in one casting. The compressor C is made of special hard bronze in order to ensure freedom from spongy places, while the suction and delivery valves are identical in shape and size so that they may be interchangeable. The compressors for larger machines are bored out of solid steel forgings. This ensures strength together with sound material. A true bore is also provided for the smooth working of the cupleathers with which the pistons are packed. The gland is made gas-tight by means of two U-leathers fitted over the compressor-rod and glycerine is forced between them under a somewhat greater pressure than that in the compressor. Any leakage which takes place is therefore of glycerine—outwards (which can be collected and used over again) and inwards—which both lubricates the interior of the compressor and fills up the clearance spaces, thereby increasing the efficiency of the machine. The superior pressure of glycerine in the gland is obtained by utilising the pressure in the condenser acting through a small intensifier, similar to those in use in hydraulic installations. Any glycerine which passes into the compresser, beyond what is necessary to fill up the clearance spaces is discharged with the gas through the delivery valves. In order to prevent this glycerine passing into the condenser coils, all the gas is delivered into a separator S and caused to impinge against the sides of this vessel. The glycerine adheres to its sides and drains to the bottom from which it may be drawn off from time to time, thus permitting the dry compressed gas to pass away by an opening at the top of the separator to the evaporator E.

One feature of these machines is the safety valve, which is fitted to the gas circuit immediately above the compressor, so that no harm can be done to the machine even if carelessly started with the stop valves closed. It consists of an ordinary spring safety valve, beneath which is a thin copper disc, designed to burst at a certain pressure. This disc can be made perfectly gas-tight, which could not be so easily accomplished by the spring safety valve alone. The latter only comes into play in the event of a rupture of the copper disc.

Anhydrous Ammonia as a Refrigerating Agent. — The most important advantages possessed by anhydrous ammonia as an

agent for cooling purposes are, its freedom from the danger of explosion, its great latent heat and low pressure of vaporisation.* The latent heat of vaporisation of 1 lb. of carbonic acid at 0° F. is 123 units, and of ammonia 555 units, while the respective pressures in lbs. per square inch, at the same temperature, are 310 lbs. in the case of carbonic acid and only 30 lbs. with ammonia. It follows, therefore, that a carbonic acid plant must be constructed to deal with pressures of about 1,000 lbs. per square inch as against only 150 lbs. or so, in an ammonia machine. The exact pressures in each case are directly proportional to the temperature of the condensing water.

As already stated, this agent is more commonly used than any other, and in the United States of America, where refrigeration is applied to an extent unknown elsewhere, the machine generally employed is on the ammonia compression principle. It is similar to the carbonic acid machine in so far as the complete system consists of (1) a compression, (2) a condensing, and (3 an expansion part; moreover, the cycle of operations is exactly the same.

De La Vergne's Refrigerating Plant.—There are many different kinds of ammonia machines in use, but a general description of one of the best known and most extensively applied—viz., the "De La Vergne" as manufactured by Messrs. L. Sterne & Co., Ltd., of the Crown Iron Works, Glasgow, may be taken as a typical example.

In the following figure, A represents the ammonia compressor driven by a steam engine R. The gas which is returned from the expansion coil N, placed in the cooling chamber, enters the cylinder A by the pipe B, and after being compressed therein it is discharged, through the pipe C into a pressure tank D, together with a certain amount of sealing oil. Here, the oil, being heavier than the ammonia gas, naturally falls to the bottom, and the hot ammonia passes from the top of this tank by a pipe E to the condensers F; where, the cooling action of cold water trickling over the pipes causes the gas to liquefy. It then passes through pipes G, G to a header H, and from thence, to a storage tank I, which is simply a receptacle for holding a reserve supply of liquid ammonia. From this tank

* A liquid with a high latent heat of evaporation need not necessarily be a good refrigerating agent, and *vice-versâ*. What is required is, that its specific heat should be low in proportion to the latent heat of evaporation. Or, we require as great a *difference* as possible between the latent heat of evaporation and the specific heat of the liquid multiplied by the range of temperature in the condenser and refrigerator.

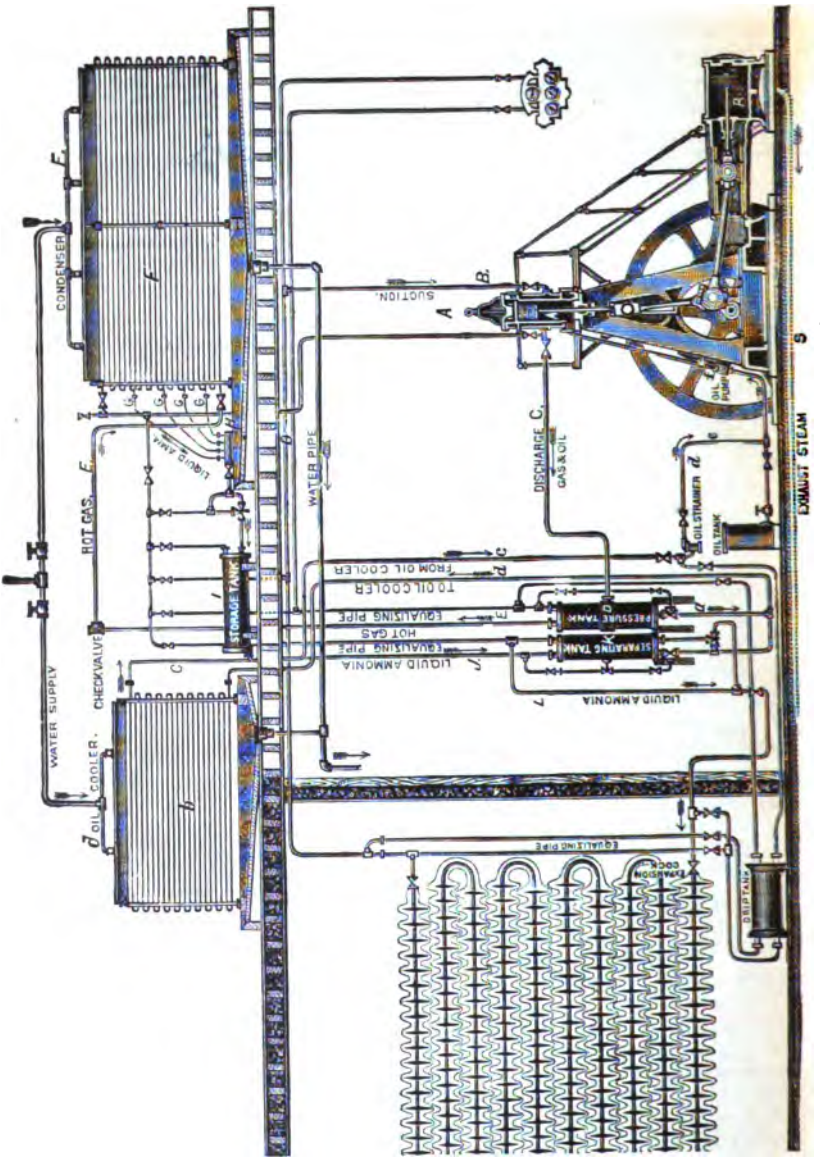

De La Vergne Refrigerating Plant. By L. Sterne & Co., Crown Iron Works, Glasgow.

it is conveyed by a pipe J to a separating vessel K, where any particles of oil that may have been carried over with the liquid are finally separated and the pure liquid ammonia is free to leave it by a pipe L to the expansion coils in the chambers to be cooled. The cock for admitting the ammonia to these coils can be regulated to any degree of minuteness. It thus serves to separate the high pressure from the low pressure part of the apparatus. Hence, the liquid ammonia on passing the expansion cock enters the cooling coils, which are maintained at a low pressure by the pumping action of the compressor. Here, it immediately flashes into gas and by abstracting from its surroundings the heat necessary to cause this change, the temperature of the room is lowered to any desired extent. After having thus done its work in the cooling chamber, the gas is returned to the compressor by a pipe B, to again undergo the same cycle of operations.

The sealing oil passes from the bottoms of the pressure and separating tanks D and K, by the pipes *a* and *d* to the oil cooler *b*; thence, by pipe *c* to the oil strainer *d* and the pipe *e* to the oil pump *f*; by which, it is again circulated through the compressor A.

De La Vergne's Double-Acting Compressor.—The accompanying figure is a section through a "De La Vergne" double-acting compressor, and shows the use of the oil seal. In all ammonia compressors, a certain amount of oil is required for lubricating purposes, and if the compressor be arranged in the ordinary way, the discharge valves at the lower end are placed either on the bottom or at the side, with the result that the oil is discharged *before* the gas. The oil ought, however, to be discharged *after* all the gas is gone; otherwise, re-expansion takes place which would entail a loss of efficiency. In the "De La Vergne" compressor this difficulty has been avoided in the following manner:—At the lower right-hand end of the compressor, two discharge valves are fitted into a side pocket, with the one fair above the other. On the down stroke, either of the valves or both may open until the piston covers the upper one, when only the lower valve is open to the condenser. In the further course of the piston and as soon as the lower valve is also closed, the upper one comes into direct communication with an annular chamber in the piston. This chamber has valves in its bottom side which open into it, as soon as all other inlets on the lower side of the piston are closed. The gas, therefore, first leaves the compressor and then the oil follows, thus permitting no gas to remain in the lower side after the completion of the down stroke. The effect of the oil seal is to make the compressor



De La Vergne's Double-Acting Compressor for his Refrigerator.

work with practically no clearance and thus a maximum of efficiency is obtained. The oil also serves to carry away a considerable amount of the heat of compression and to seal all the valves and stuffing-boxes.

Attention may now be drawn to a few of the details of the above plant. In the first place, it will be noticed that the ammonia condenser is not of the ordinary type where the coils containing the gas are usually submerged in a water tank, but they are of the open or atmospheric type. Here, water is kept constantly trickling over the condenser pipes, and the cooling action is therefore considerably assisted by the evaporation thereof from the surface of the pipes, which enables a maximum of condensation to be effected with a minimum of water supply. It also leaves all the pipes of the condenser open for examination and cleansing. This style of condenser is now coming into extensive use for the condensation of steam in large factories. In the second place, it will be seen that the refrigerating or cooling effect is caused by the direct expansion of the ammonia in pipes placed in the chamber to be cooled. This does away with the unavoidable loss of efficiency due to the use of a supplementary medium such as brine. It, however, necessitates very careful coupling up and jointing all the expansion coils, in order to prevent any leakage of the ammonia gas; more especially, in the case of a large plant where there may be as much as ten or more miles of piping in these cooling coils. In practice, however, these details have been so carefully worked out, that many hundreds of miles of such piping are constantly at work without giving the slightest trouble. Consequently, the old-fashioned method of brine circulation is not now so generally employed except on board ship, where there is a possibility of undue rocking or straining of the pipes and where it is considered advisable to use something that would cause no disagreeable odour in case of a broken pipe or joint.

In applying the refrigerating machine to the manufacture of ice, the simplest method is to place the expansion or cooling coils in a tank filled with brine or other non-congealable liquid, while the water to be frozen is placed in moulds of suitable size, which are then inserted into this brine until frozen. The purpose served by the brine in this case is to convey the heat from the water to the cooling pipes. It is therefore generally kept in slow circulation in order to ensure that the temperature shall be as uniform as possible throughout the tank. If ordinary well water be placed in the moulds, the resulting ice will contain so much air that it will be turned out of a milky white and opaque colour; but if the water whilst in the process of freezing be kept

in slow motion by means of agitators, this air escapes, and a clear glassy ice is the result.

Another method of obtaining clear ice is to use distilled water. This has also the advantage of getting rid of any objectionable matter which might be in solution.

The Linde System of Refrigeration.—This system was first introduced into Germany in the year 1875 by Professor Linde, who was then one of the teaching staff at Munich University. In this country, however, prior to 1888, the principal cold-producing machinery, as manufactured for both land and marine purposes, was the simple cold air machine, in which refrigeration is produced by the compression, cooling when under compression by means of water and subsequent expansion of ordinary atmospheric air. These machines, although simple in construction and giving very good results, possess the disadvantage of requiring a large amount of power to work them in comparison with those employing more efficient refrigerating agents. Consequently, the former method has now very largely given way to one or other of the latter, of which the Linde system is one of the most successful, seeing that over 3,000 of these machines have been constructed up to September, 1897, representing an output, as rated by the capability of producing 69,200 tons of ice every twenty-four hours. In America the largest machine turned out upon any system is rated at 500 tons of ice per twenty-four hours.

The Linde System of Refrigeration is identical in principle, and only differs in mechanical details from the De La Vergne previously described. It is, therefore, based on the evaporation of liquid anhydrous ammonia and the subsequent liquefaction thereof by means of mechanical compression, together with the cooling of the vapour thus formed, so as to enable it to be used over and over again. As will be seen from the accompanying illustration, the self-contained motive-power plant, as chiefly used on board ship, consists of a horizontal steam engine on the right, with a horizontal duplex compressor pump to the left, and an ammonia condenser in the sole plate. As far as the compressor is concerned, the chief differences between the Linde and the De La Vergne systems are:—

(1) That in the former a horizontal compressor is used instead of a vertical one in the latter case.

(2) That a special oil (not susceptible to change at any temperature attainable by the machine, which does not contain any acid or other deleterious matter, and which does not saponify when brought into contact with ammonia is used solely for lubricating purposes. Whereas, the oil used in the De La

Vergne system serves not only as a lubricant to the working parts, but also to partly carry away the heat of compression, and, further, to fill up the clearance spaces, as well as to seal the valves, glands, &c., so as to prevent the escape and consequent inconvenient smell of ammonia.

(3) In the Linde system a small quantity of liquid ammonia is introduced into the compressor during each suction stroke for



SHIP REFRIGERATING MACHINERY ON THE LINDE SYSTEM.
BY THE LINDE BRITISH REFRIGERATING COMPANY.

the purpose of cooling the vapour of ammonia. This liquid ammonia evaporates during compression, and thus the heat due to compression, which would otherwise appear as sensible heat, is thereby absorbed and rendered latent in producing the change in the physical state of the liquid. The curve of compression is thus kept down as nearly as may be to the isothermal line, and

the power required for compression is to this extent correspondingly reduced.

Apparatus for Transmitting the Cold Produced to the Chambers requiring Refrigeration.—The following general principles are adopted for transferring the cold generated by the refrigerating machinery to the chambers or rooms requiring to be cooled.

First Method.—An uncongealable solution of salt (chloride of sodium) in water is reduced by the refrigerating machine to a low temperature, and this liquor acts as transmitter of cold in one of the following methods:—

(*a*) The cold brine is constantly circulated from the brine refrigerator through pipes placed in the refrigerated chambers, and returned to the brine cooler. The result is that not only is heat abstracted from the air of the refrigerated rooms, but also a large degree of the moisture which may be present in them. This moisture is condensed on the exterior of the brine pipe systems either in the form of condensed water or hoar-frost. Suitable drip trays are provided, in order to prevent this moisture from falling upon the contents of the rooms. The circulation of air with this system is a moderate one, being produced merely by the differences between the temperatures prevailing near the brine-pipes and those in the lower parts of the rooms.

(*b*) The brine is cooled in a shallow rectangular open tank containing the evaporator coils. On the tank is mounted a number of slowly revolving transverse shafts, and on each shaft is fixed a number of parallel discs, partly immersed in the brine, the entire apparatus being placed in an insulated passage through which an air current is continually passed by a fan, in a direction parallel to the revolving discs. It will be seen, that as the discs revolve and are kept covered by a film of the refrigerated brine, the air passing between the disc-spaces becomes cooled, and produces a low temperature in any chamber or room into which it may be conducted through properly arranged air-trunks. As a rule the air is always taken back from the cold rooms, passed over the discs and returned to the cold rooms, and any required amount of fresh air is introduced by means of adjustable openings in the air-trunks, communicating with the outer atmosphere. In this instance, also, moisture may be removed from the refrigerated rooms and deposited in the brine contained in the trough. No accumulation of frost can take place, and the refrigerated surfaces are always perfectly active. The circumstance of all moisture being deposited in the brine necessitates either a periodical loss of the same or its re-concentration. The fan produces a very effective air circulation within the rooms to

be cooled. This in most cases is extremely desirable, and, as will be readily understood, produces the most beneficial results.

Second Method.—Instead of using an uncongealable liquid as a bearer of cold, the refrigerator coils (in which the vaporisation of the liquid anhydrous ammonia takes place) are sometimes constructed with extra large surfaces, and placed either in the upper part of the rooms to be cooled, or in a separate chamber. In the latter case, a fan constantly circulates the air between this chamber and the refrigerated rooms. This is the system generally adopted on board ships, and has been found to be in all respects most satisfactory. In cases where the air temperature is not sufficiently high to cause a complete removal of the snow deposited on the ammonia-coils, the snow is thawed by the ammonia vapours themselves, the evaporator-coils being for the time used as a condenser. Occasionally the snow is thawed by a current of hot air taken from the outside.

Although all of these methods have been applied on an extensive scale, the system most strongly recommended in cases where its application is possible is the combination of revolving discs immersed in brine. There are no brine or ammonia pipes in the rooms; whilst the rapid air circulation by the fan is easily managed, and has been found in most cases to be requisite for obtaining a satisfactory result as to purity, dryness, and equable temperature in all the rooms.

Where circumstances require the refrigerated rooms to be at a distance from the refrigerating machine, it is generally most convenient to place bundles of brine pipes in each room; but even in such a case, in the event of a small amount of motive power being available close to such rooms, the system of revolving discs and fans can be readily applied, the brine being cooled in a refrigerator near the compressor, and conveyed to and from the disc tanks through insulated pipes.

A large beef-chilling plant on the Linde system was erected in the beginning of 1890 at the Woodside lairage of the Mersey Dock and Harbour Board. It is capable of chilling 660 carcases of beef, each weighing about 9 cwts., from 90 degrees Fahr. to 33 degrees in 17 hours. It consists of a horizontal compound tandem jet-condensing steam engine, which drives a double-acting Linde compressor at the rate of about 65 revolutions per minute, when supplied with steam at 120 lbs. pressure from a marine type boiler. The air-cooling apparatus consists of two disc tanks, placed above the chill rooms, at one end. Each disc system has its own fan, which draws the air from the top of each of the chill rooms, passes it over the discs, and drives it into the rooms at the opposite end to that from which it is withdrawn.

The ammonia condenser is placed in the compressor room, and is supplied with cooling water by a pump which takes its supply from a well, fed with the drainage water from the Mersey Tunnel. After passing through the ammonia condenser the water is used in the condenser of the steam engine. There are six chill rooms, each about 55 ft. long by 14 ft. wide, and about 13 ft. high. The walls of the rooms are built of brick, with air spaces. The floors are cement, and the ceilings are timber, covered with a layer of fine ashes. The air-cooling apparatus is contained in an insulated casing, which is so arranged as to cause the air to come in contact with the cooled surfaces of the discs.

The following is a list of some of the books and papers on Hydraulics and Hydraulic Machinery :—

Hydraulic Machinery, by R. Gordon Blaine. (E. & F. N. Spon, Ltd., London, 1897.)

Recent Hydraulic Experiments. Paper by Major A. Cunningham. Proc. Inst. C.E., vol. lxxi., p. 1.

Hydraulic Appliances at the Forth Bridge Works. Paper by E. W. Moir. Proc. Inst. C.E., vol. xci., p. 402.

The 160-Ton Hydraulic Crane at Malta Dockyard Extension Works. Paper by C. & C. H. Colson. Proc. Inst. C.E., vol. cxiv., p. 289.

On Machine Tools and other Labour-Saving Appliances Worked by Hydraulic Pressure. Paper by R. H. Tweddell. Proc. Inst. C.E., vol. xxiii., p. 64.

The Barry Dock Works, including the Hydraulic Machinery and the Mode of Tipping Coal. Paper by J. Robinson. Proc. Inst., C.E., vol. ci., p. 129.

The Distribution of Hydraulic Power in London. Paper by E. B. Ellington. Proc. Inst. C.E., vol. xciv., p. 1.

Hydraulic-Power Supply in London. Paper by E. B. Ellington. Proc. Inst. C.E., vol. cxv., p. 220.

Forging by Hydraulic Pressure. Paper by R. H. Tweddell. Proc. Inst. C.E., vol. cxvii., p. 1.

Hydraulic-Power Supply in Towns. (Glasgow, Manchester, Buenos Ayres, &c.) By Edward B. Ellington, M. Inst. M.E. (Proc. Inst. Mechanical Engineers, Glasgow Meeting, 1895).

Water-Pressure Engines for Mining Purposes. Paper by H. Davey, M. Inst. C.E. Proc. Inst. M.E., 1880, p. 245.

Hydraulic Flanging of Steel Plates. Paper by Easton & Anderson. Proc. Inst. M.E., 1882, p. 518.

Portable Hydraulic Drilling Machine. Paper by M. Berrier-Fontaine. Proc. Inst. M.E., 1887, p. 72.

Lifts in the Eiffel Tower. Paper by A. Ansaloni. Proc. Inst. M.E., 1889, p. 350.

Hydraulic Packing Presses. Paper by C. Hopkinson. Proc. Inst. C.E., vol. xcix., p. 275.

The Treatment of Steel by Hydraulic Pressure and the Plant Employed for the purpose. Paper by W. H. Greenwood. Proc. Inst. C.E., vol. xcviii., p. 83.

Hydraulic Propulsion. Paper by S. W. Barnaby. Proc. Inst. C.E., vol. xxvii., p. 83.

A Hydraulic Pumping Engine. Paper by H. D. Pearsall. Proc. Inst. C.E., vol. cvi., p. 292.

Hydraulic Work in the Irawadi Delta. Paper by R. Gordon. Proc. Inst. C.E., vol. cxiii., p. 276.

Centrifugal Pumps, Turbines, and Water Motors, by C. H. Innes, M.A. (The Technical Publishing Co., Ltd., Manchester.)

Lifting and Hauling Appliances in Portsmouth Dockyard. Paper by J. T. Corner. Proc. Inst. M.E., 1892, p. 295.

Hydraulic Power and Hydraulic Machinery, by Henry Robinson. (Chas. Griffin & Co., London, 1896.)

Hydraulic Motors, Turbines, and Pressure Engines, by G. R. Bodmer. (Whittaker & Co., London, 1889.)

A Treatise on Hydraulics, by M. Merriman. (John Wiley & Sons, New York, 1895.)

Hydrostatics and Elementary Hydrokinetics, by G. M. Minchin. (Oxford Press, Oxford, 1892.)

Hydraulic Machinery for Glasgow Harbour Tunnel, as Constructed and Erected by the Otis Elevator Co., New Yonkers, New York. See *Engineering,* May and June, 1895.

Paper on *Refrigerating Apparatus,* by Prof. Carl Linde, of Munich. *Journal of the Society of Arts,* 9th March, 1894.

Paper on *Experiments on a Two-Stage Air Compressor,* by John Goodman, Wh.Sc. Proc. Inst. C.E., vol. cxxviii., and also *The Practical Engineer,* 30th July, 1897.

Compend of Mechanical Refrigeration, by J. E. Siebel. (H. S. Rich & Co., Chicago, 1895.) In this book there are several important tables and other valuable information regarding refrigerators.

Adaptation of Hydraulic Power in the Manufacture of Iron and Steel. Paper by James L. Biggart. *Journal of the West of Scotland Iron and Steel Institute,* 1893.

Application of a System of Combined Steam and Hydraulic Machinery to the Loading, Discharging, and Steering of Steamships. Paper by A. Betts Brown, F.R.S.E. Proc. Inst. Nav. Arch., 1890.

The Theory and Practice of Mechanical Refrigeration. Paper by T. R. Murray, Wh. Sch. Proc. Inst. Eng. and Shipbuilders Scot., 1897-98.

The Mechanical Production of Cold. Howard Lecture by Prof. J. A. Ewing, F.R.S. Delivered Feby. 4, 1897, before The Society of Arts, London. See their *Journal* or *The Practical Engineer* for Dec., 1897, and Jan., 1898.

LECTURE XXXVII.—QUESTIONS.

1. Explain the fundamental principles upon which a refrigerating machine works. Note specially what becomes of the different quantities of heat generated and absorbed.
2. Sketch the essential parts of a refrigerator, and describe its action.
3. What are the advantages which a vapour possesses over a permanent gas, such as air, for refrigerative purposes?
4. What are the requirements of an economical medium for use in a refrigerator?
5. Sketch and explain the plant required for producing cold by means of carbon dioxide.
6. Explain the reasons that have led to the adoption of anhydrous ammonia in most modern refrigerators, and mention some of the properties of this vapour.
7. Sketch and describe any well-known arrangement for refrigerating, using anhydrous ammonia.
8. Explain and illustrate some of the ways of communicating cold to a chamber from a refrigerator.

APPENDIX.

1899 Science and Art Examination on Applied Mechanics.

Instructions for Advanced Stage.

You are not permitted to answer more than *seven* questions.

The value attached to each question is shown in brackets after the question.

21. What is the nature of the forces producing the simplest reciprocating motion? A body of 40 lb. weight hangs from a spiral spring and vibrates vertically; what is the periodic time of its vibration if the stiffness of the spring is such that a weight of 10 lb. would elongate it 0.1 foot? (25.)

22. Prove the formula for the kinetic energy of a moving body. A ball weighing 1 lb., moving at 1,200 feet per second, passes through a plate of iron in 0.002 second, and its velocity is reduced to 200 feet per second. Find the work done in passing through the plate, and the average force during the time of its passage. (25.)

23. Describe, with sketches, a brake suitable for about 10 horse-power from a gas engine. How would you calculate the brake-power? If, when the brake-power is 9.7, the indicated power is 11.8, and when the brake-power is 0 the indicated power is 1.75, what is the probable brake-power when the indicated power is 7.25? Use squared paper or not as you please. State the reasons for your method of arriving at the result. (30.)

24. If a thin vessel is subjected to fluid pressure p inside (in excess of the outside pressure), prove that the total bursting force at any plane section is pA if A is the area of the whole section. How do we calculate the tensile stress in the section a of the metal? Find the rule for the stress in a thin spherical vessel. Does the rule apply to a thick vessel? Give reasons for your answer. (25.)

25. Describe, with sketches, a common screw-jack. If the radius at which the hand acts is 15 inches, and the pitch of the screw is 0.3 inch, what is the velocity ratio? How would you proceed to find its mechanical advantage experimentally under various loads? What sort of results would you expect to find? (30.)

26. The vane of a wheel of an internal-flow turbine is normal to the rim which moves at 40 feet per second. Water is guided so as to enter the rim with a radial velocity of 4 feet per second; what must be the angle made by the guide blade with the rim, if the water is to enter without shock? If the circumferential area of all the openings of the rim is 1.5 square feet.

what volume of water flows per second? We use convenient but not very exact language when we ask—what is the total tangential momentum per second entering the rim? (30.)

27. Sketch and describe the construction of either the hub of a cycle wheel or of any other ball bearing with which you are acquainted. Explain the advantages and disadvantages of ball bearings over the ordinary axle or shaft bearing, stating the reasons for your answers. (25.)

28. Sketch and describe the mechanism by which the slide or saddle of a screw-cutting lathe can be put into gear with the leading screw, so as to traverse the slide automatically along the bed of the lathe, or be thrown out of gear so as to allow of the slide being traversed by hand.

Describe how a screw-thread can be cut in a lathe, and determine the number of teeth on the change wheels, and sketch their arrangement when cutting a screw-bolt with 10 threads to the inch on a lathe in which the leading screw is of ½" pitch. (25.)

29. Sketch and describe the construction and working of the mechanism, including the driving pulleys, by which the table of a machine for planing metals is moved backwards and forwards. If the travel of the table is 9 feet, and it makes 80 double strokes per hour, cutting both ways, find the resistance to motion if there is 5 horse-power actually expended at the tool. (25.)

30. Suppose the vertical loads and supporting forces of a horizontal beam to be known, show how we find (1) the total shearing force at any section, (2) the position of the neutral line, (3) the tensile or compressive stress at any place. Prove your statements. (30.)

31. In calculating by graphical methods the tensile or compressive forces in the several members of braced girders, why is it usual to represent the weight of, or upon, the several bars by equivalent forces acting at the joints, and to assume that the joints are frictionless pin joints or hinges?

A Warren girder has six equal bays on the bottom flange, the girder is 90 ft. span and 13′ 0″ deep. It is loaded with a weight of 20 tons resting on the apex of the top flange, which is 37′ 6″ from the left abutment. Determine either graphically or analytically the forces in the diagonals and flanges of the girder produced by this load. (25.)

32. A railway bridge over a road is 40 feet span. An engine with its tender stands upon the bridge. The weights on the leading, the driving, and the trailing axles of the engine are 9, 15, and 8 tons respectively, while the load on the three axles of the tender is 7 tons on each. The engine stands so that the leading axle is 2½ feet from the end of the bridge, and the distance between the centres of the engine axles is 8 feet, and between the tender axles is 4′ 6″, while between the trailing axle of the engine and the leading axle of the tender is 8 feet. Draw the bending moment and shearing force diagrams for the above position of the engine, and write down the maximum value of the bending moment and also the value and position of the maximum shearing force. (25.)

33. What sort of experiments have been made to find the effect of repeated applications of load upon the strength of materials? State some figures giving a roughly correct idea of the result of these experiments. (25.)

34. Describe experiments to compare the speed of a fly-wheel with the work given to it by a falling weight. If you have not made such experiments, so that the exact method of finding the speed, of correcting for friction, &c., are unknown to you, you had better not attempt this question. (30.)

1899 Science and Art Examination on Applied Mechanics.

Instructions for Honours.—Part I.

Read the General Instructions.

You are not permitted to answer more than *eight* questions.

The value attached to each question is shown in brackets after the question.

41. Knowing the axial and lateral strains in a tie-bar of homogeneous material when subjected to a tensile force, show how we calculate the moduli of rigidity and of cubical elasticity of the material. (40.)

42. Describe with sketches a good ball bearing of any kind. State clearly the nature of rolling resistance. What is known about its amount, experimentally? What are the advantages and disadvantages attending the use of such bearings? (30.)

43. You are asked to find the performances and efficiencies under various steady loads of a large gas engine using Dowson gas. It has two fly-wheels, and its maximum brake horse-power is about 100. Make good sketches of the brake or brakes; how would you keep it or them cool? You need not describe carefully how we take indicator diagrams; but you must state what precautions are to be taken for accuracy. What gas measurements would you take? How would you find the heat given to the water-jacket? What sort of results as to brake and indicated power would you expect to find? (30.)

44. Prove the ordinary formula for the deflection of a beam of length l, supported at its ends and loaded in the middle with a load W.

A beam of uniform rectangular section supported at the ends is 20′ between the supports; what should be its depth in order that the deflection may not exceed .25″ under a maximum stress of 8000 lbs. per square inch of section? $E = 28 \times 10^6$ lb. per sq. inch. (40.)

45. If a telegraph wire never reaches permanent set, find a formula approximately correct showing how the dip alters with temperature. (30.)

46. Find the inside and outside diameters of a hollow steel shaft, the internal diameter being $\frac{5}{8}$ of the external diameter. The shaft is to transmit 6,000 H.P. at 116 revolutions. Suppose the maximum twisting moment to be 1.3 times its mean value and the maximum stress allowed in the material to be 10,000 lbs. per square inch. Prove the truth of the formula which you use. (30.)

47. A body weighing 322 lbs. is lifted by a force of F lbs. which alters. When the body has risen through the distance x feet, the force in lbs. for the several values of x is as follows (or would be if the body rose as far):—

x	0	1	2	3	4	5.5	7	9	11	12.5	14	17	20
F	540	540	540	530	500	460	310	220	190	190	190	190	190

Using squared paper, find the velocity in each position and the time taken by the body to get to each position counting from $x=0$, the velocity then being 5 feet per second. (40.)

48. A structure has a hollow circular section 10 inches outside diameter and 8 inches inside. The resultant of all the loads and supporting forces acting on one side of the section has a component of 30 tons normal to the section and it acts at 2 inches from the centre; find the maximum and minimum stresses in the section. (30.)

49. Assume that a pipe of 10" diameter inside and 14" diameter outside, of homogeneous material, can withstand no tensile stress except endwise. It is wound outside with hoop-iron in tension, which produces an external radial pressure p_0 on the material, the tangential compressive stress produced by this near the outside being 500 lbs. per square inch when there is atmospheric pressure inside the pipe. Find p_0 and the tensile force in the hoop-iron per unit length of pipe. What is the tangential compressive stress everywhere?

Find what is the greatest internal pressure that the pipe will withstand, and the stress everywhere when there is this pressure inside.

Prove the formulæ used by you. (40.)

50. An inward flow-turbine for a fall of 30 feet and 20 cubic feet of water per second; sketch the turbine; give its principal dimensions and speed and the angles of guide blades and vanes. What is the kinetic energy of a pound of water just entering the wheel? Neglect losses by friction. (40.)

51. Prove the formula used for finding the resultant pressure on a sloping plane interface, with any shape of boundary underneath the surface of a liquid. Also find the position of the resultant. Apply the formula to the case of a rectangle with its highest horizontal side 5 feet long at 20 feet below the surface, its other sides being 12 feet long and making 30° with the horizontal. (30.)

52. A symmetrically loaded beam of uniform section; given the diagram of bending moment when supported at its ends, what is the easy rule for obtaining the diagram when the beam is fixed at the ends? Prove the rule to be correct. (40.)

Instructions for Honours.—Part II.

Read the General Instructions.

You may not attempt more than *eight* questions.

The value attached to each question is shown in brackets after the question.

Note.—*No Candidate is eligible for examination in Part II. of Honours who has not already obtained a pass in Honours—Part I. in* 1898, *or a* 1*st or* 2*nd Class in Honours of the same subject in a previous year.*

61. If a telegraph wire never reaches permanent set, find a formula approximately correct showing how the dip alters with the temperature. (50.)

62. A uniform beam of rectangular section is fixed at the ends, is 20 feet long, has a load of 10 tons at its middle, and one of 7 tons at 5 feet from one end. Find the diagram of bending moment. (50.)

63. A spiral spring of angle a, radius of coils r, length of wire l, is fastened at its upper end; to the lower end we apply a small axial load F

and a small couple L about the axis of the spiral; find the axial elongation and the rotation of the lower end. (50.)

64. If the tractive force of a motor car on a level road of any kind is a function of the speed, show that for a given length of journey on a road of this kind with any gradients, if the duration of the journey is settled, to expend on the journey a minimum amount of propelling energy, the speed ought to be constant. Why is it not fair to assume from this result that the speed of a bicycle or animal-drawn carriage ought to be constant?

A very elementary knowledge of the calculus of variations seems to be needed. (50.)

65. A round bar of steel, 1 inch diameter, 8 feet long, is subjected at the centres of its ends to equal and opposite loads of 1,500 lbs. What is the stress if the rod is kept from bending? If the rod lies horizontally, only supported at the ends, what is the maximum stress due to its own weight? If now it is subjected to the endlong loads when lying horizontally and supported at the ends, what is the maximum stress? Take $E=3\times10^7$ lbs. per square inch. (50.)

66. A body of weight W is at the end of a horizontal lever OBW hinged at O; it is supported by a vertical spiral spring attached to the point B. Given the stiffness of the spring, show how we find the time of vertical vibration, neglecting the inertias of lever and spring; the motion of the body being resisted by a friction of an amount which is proportional to the speed. Now let the support of the spring get a simple vertical vibratory motion, what is the motion of W after sufficient time has elapsed to still its natural vibrations? (50.)

67. Describe the reasoning and experimental work of Professor Reynolds which led to his law for friction of fluids in pipes. What is the law? How is it related to the well-known D'Arcy formula? (50.)

68. A steel tube 7 inches internal and 10 inches external diameter has steel strip wound on it to the external diameter of 15 inches under a constant winding stress of 20 tons per square inch. Imagine no interstices in the layers of strip. Show by a curve the stress at various places in the solid metal and in the winding. (50.)

69. A point x, y, z is displaced to $x+u$, $y+v$, $z+w$. Write out the six important kinds of strain; also what are called "the rotations." Express the connection between stresses and strains. Deduce the equations of equilibrium between the stresses and volumetric forces, and convert them into the general equations of strain. (50.)

70. In what way may a piston ring be made, so that, without the help of auxiliary springs, it will produce a uniform pressure against the inside surface of the cylinder. Prove your statement to be correct. (50.)

71. A link has motion parallel to a plane. Given the velocities and accelerations of two pins, how do we draw the velocity and acceleration diagrams which give at once the velocity and acceleration of any point in the link? Prove your two constructions to be correct. (50.)

72. The resultant of all the loads and supporting forces acting on one side of a cross section of a structure like a metal arch is given in position. Prove the rule by which we find the tensile or compressive stress at any point in the section. Such a cross section is a circular ring of 10 inches outside diameter and 8 inches inside; the resultant has a component of 30 tons normal to the section, and acts at 2 inches from the centre; find the maximum and minimum compressive stresses in the section. (50.)

EXAMINATION TABLES.

USEFUL CONSTANTS.

1 Inch = 25·4 millimetres.

1 Gallon = ·1605 cubic foot = 10 lbs. of water at 62° F.

1 Knot = 6080 feet per hour.

Weight of 1 lb. in London = 445,000 dynes.

One pound avoirdupois = 7000 grains = 453·6 grammes.

1 Cubic foot of water weighs 62·3 lbs.

1 Cubic foot of air at 0° C. and 1 atmosphere, weighs ·0807 lb.

1 Cubic foot of Hydrogen at 0° C. and 1 atmosphere, weighs ·00557 lb.

1 Foot-pound = $1{\cdot}3562 \times 10^7$ ergs.

1 Horse-power-hour = 33000 × 60 foot-pounds.

1 Electrical unit = 1000 watt-hours.

Joule's Equivalent to suit Regnault's H, is $\begin{cases} 774 \text{ ft.-lbs.} = 1 \text{ Fah. unit.} \\ 1393 \text{ ft.-lbs.} = 1 \text{ Cent. } \text{"} \end{cases}$

1 Horse-power = 33000 foot-pounds per minute = 746 watts.

Volts × amperes = watts.

1 Atmosphere = 14·7 lb. per square inch = 2116 lbs. per square foot = 760 m.m. of mercury = 10^6 dynes per sq. cm. nearly.

A Column of water 2·3 feet high corresponds to a pressure of 1 lb. per square inch.

Absolute temp., $t = \theta°$ C. + 273°·7.

Regnault's H = 606·5 + ·305 $\theta°$ C. = 1082 + ·305 $\theta°$ F.

$p\,u^{1{\cdot}0646} = 479$

$$\log_{10} p = 6{\cdot}1007 - \frac{B}{t} - \frac{C}{t^2},$$

where $\log_{10} B = 3{\cdot}1812$, $\log_{10} C = 5{\cdot}0871$,

p is in pounds per square inch, t is absolute temperature Centigrade, u is the volume in cubic feet per pound of steam.

$\pi = 3{\cdot}1416$.

One radian = 57·3 degrees.

To convert common into Napierian logarithms, multiply by 2·3026.

The base of the Napierian logarithms is $e = 2{\cdot}7183$.

The value of g at London = 32·182 feet per sec. per sec.

Logarithms.

	0	1	2	3	4	5	6	7	8	9	1	2	3	4	5	6	7	8	9
10	0000	0043	0086	0128	0170	0212	0253	0294	0334	0374	4	8	12	17	21	25	29	33	37
11	0414	0453	0492	0531	0569	0607	0645	0682	0719	0755	4	8	11	15	19	23	26	30	34
12	0792	0828	0864	0899	0934	0969	1004	1038	1072	1106	3	7	10	14	17	21	24	28	31
13	1139	1173	1206	1239	1271	1303	1335	1367	1399	1430	3	6	10	13	16	19	23	26	29
14	1461	1492	1523	1553	1584	1614	1644	1673	1703	1732	3	6	9	12	15	18	21	24	27
15	1761	1790	1818	1847	1875	1903	1931	1959	1987	2014	3	6	8	11	14	17	20	22	25
16	2041	2068	2095	2122	2148	2175	2201	2227	2253	2279	3	5	8	11	13	16	18	21	24
17	2304	2330	2355	2380	2405	2430	2455	2480	2504	2529	2	5	7	10	12	15	17	20	22
18	2553	2577	2601	2625	2648	2672	2695	2718	2742	2765	2	5	7	9	12	14	16	19	21
19	2788	2810	2833	2856	2878	2900	2923	2945	2967	2989	2	4	7	9	11	13	16	18	20
20	3010	3032	3054	3075	3096	3118	3139	3160	3181	3201	2	4	6	8	11	13	15	17	19
21	3222	3243	3263	3284	3304	3324	3345	3365	3385	3404	2	4	6	8	10	12	14	16	18
22	3424	3444	3464	3483	3502	3522	3541	3560	3579	3598	2	4	6	8	10	12	14	15	17
23	3617	3636	3655	3674	3692	3711	3729	3747	3766	3784	2	4	6	7	9	11	13	15	17
24	3802	3820	3838	3856	3874	3892	3909	3927	3945	3962	2	4	5	7	9	11	12	14	16
25	3979	3997	4014	4031	4048	4065	4082	4099	4116	4133	2	3	5	7	9	10	12	14	15
26	4150	4166	4183	4200	4216	4232	4249	4265	4281	4298	2	3	5	7	8	10	11	13	15
27	4314	4330	4346	4362	4378	4393	4409	4425	4440	4456	2	3	5	6	8	9	11	13	14
28	4472	4487	4502	4518	4533	4548	4564	4579	4594	4609	2	3	5	6	8	9	11	12	14
29	4624	4639	4654	4669	4683	4698	4713	4728	4742	4757	1	3	4	6	7	9	10	12	13
30	4771	4786	4800	4814	4829	4843	4857	4871	4886	4900	1	3	4	6	7	9	10	11	13
31	4914	4928	4942	4955	4969	4983	4997	5011	5024	5038	1	3	4	6	7	8	10	11	12
32	5051	5065	5079	5092	5105	5119	5132	5145	5159	5172	1	3	4	5	7	8	9	11	12
33	5185	5198	5211	5224	5237	5250	5263	5276	5289	5302	1	3	4	5	6	8	9	10	12
34	5315	5328	5340	5353	5366	5378	5391	5403	5416	5428	1	3	4	5	6	8	9	10	11
35	5441	5453	5465	5478	5490	5502	5514	5527	5539	5551	1	2	4	5	6	7	9	10	11
36	5563	5575	5587	5599	5611	5623	5635	5647	5658	5670	1	2	4	5	6	7	8	10	11
37	5682	5694	5705	5717	5729	5740	5752	5763	5775	5786	1	2	3	5	6	7	8	9	10
38	5798	5809	5821	5832	5843	5855	5866	5877	5888	5899	1	2	3	5	6	7	8	9	10
39	5911	5922	5933	5944	5955	5966	5977	5988	5999	6010	1	2	3	4	5	7	8	9	10
40	6021	6031	6042	6053	6064	6075	6085	6096	6107	6117	1	2	3	4	5	6	8	9	10
41	6128	6138	6149	6160	6170	6180	6191	6201	6212	6222	1	2	3	4	5	6	7	8	9
42	6232	6243	6253	6263	6274	6284	6294	6304	6314	6325	1	2	3	4	5	6	7	8	9
43	6335	6345	6355	6365	6375	6385	6395	6405	6415	6425	1	2	3	4	5	6	7	8	9
44	6435	6444	6454	6464	6474	6484	6493	6503	6513	6522	1	2	3	4	5	6	7	8	9
45	6532	6542	6551	6561	6571	6580	6590	6599	6609	6618	1	2	3	4	5	6	7	8	9
46	6628	6637	6646	6656	6665	6675	6684	6693	6702	6712	1	2	3	4	5	6	7	7	8
47	6721	6730	6739	6749	6758	6767	6776	6785	6794	6803	1	2	3	4	5	5	6	7	8
48	6812	6821	6830	6839	6848	6857	6866	6875	6884	6893	1	2	3	4	4	5	6	7	8
49	6902	6911	6920	6928	6937	6946	6955	6964	6972	6981	1	2	3	4	4	5	6	7	8
50	6990	6998	7007	7016	7024	7033	7042	7050	7059	7067	1	2	3	3	4	5	6	7	8
51	7076	7084	7093	7101	7110	7118	7126	7135	7143	7152	1	2	3	3	4	5	6	7	8
52	7160	7168	7177	7185	7193	7202	7210	7218	7226	7235	1	2	2	3	4	5	6	7	7
53	7243	7251	7259	7267	7275	7284	7292	7300	7308	7316	1	2	2	3	4	5	6	6	7
54	7324	7332	7340	7348	7356	7364	7372	7380	7388	7396	1	2	2	3	4	5	6	6	7

Logarithms.

	0	1	2	3	4	5	6	7	8	9	1	2	3	4	5	6	7	8	9
55	7404	7412	7419	7427	7435	7443	7451	7459	7466	7474	1	2	2	3	4	5	5	6	7
56	7482	7490	7497	7505	7513	7520	7528	7536	7543	7551	1	2	2	3	4	5	5	6	7
57	7559	7566	7574	7582	7589	7597	7604	7612	7619	7627	1	2	2	3	4	5	5	6	7
58	7634	7642	7649	7657	7664	7672	7679	7686	7694	7701	1	1	2	3	4	4	5	6	7
59	7709	7716	7723	7731	7738	7745	7752	7760	7767	7774	1	1	2	3	4	4	5	6	7
60	7782	7789	7796	7803	7810	7818	7825	7832	7839	7846	1	1	2	3	4	4	5	6	6
61	7853	7860	7868	7875	7882	7889	7896	7903	7910	7917	1	1	2	3	4	4	5	6	6
62	7924	7931	7938	7945	7952	7959	7966	7973	7980	7987	1	1	2	3	3	4	5	6	6
63	7993	8000	8007	8014	8021	8028	8035	8041	8048	8055	1	1	2	3	3	4	5	5	6
64	8062	8069	8075	8082	8089	8096	8102	8109	8116	8122	1	1	2	3	3	4	5	5	6
65	8129	8136	8142	8149	8156	8162	8169	8176	8182	8189	1	1	2	3	3	4	5	5	6
66	8195	8202	8209	8215	8222	8228	8235	8241	8248	8254	1	1	2	3	3	4	5	5	6
67	8261	8267	8274	8280	8287	8293	8299	8306	8312	8319	1	1	2	3	3	4	5	5	6
68	8325	8331	8338	8344	8351	8357	8363	8370	8376	8382	1	1	2	3	3	4	4	5	6
69	8388	8395	8401	8407	8414	8420	8426	8432	8439	8445	1	1	2	2	3	4	4	5	6
70	8451	8457	8463	8470	8476	8482	8488	8494	8500	8506	1	1	2	2	3	4	4	5	6
71	8513	8519	8525	8531	8537	8543	8549	8555	8561	8567	1	1	2	2	3	4	4	5	5
72	8573	8579	8585	8591	8597	8603	8609	8615	8621	8627	1	1	2	2	3	4	4	5	5
73	8633	8639	8645	8651	8657	8663	8669	8675	8681	8686	1	1	2	2	3	4	4	5	5
74	8692	8698	8704	8710	8716	8722	8727	8733	8739	8745	1	1	2	2	3	4	4	5	5
75	8751	8756	8762	8768	8774	8779	8785	8791	8797	8802	1	1	2	2	3	3	4	5	5
76	8808	8814	8820	8825	8831	8837	8842	8848	8854	8859	1	1	2	2	3	3	4	5	5
77	8865	8871	8876	8882	8887	8893	8899	8904	8910	8915	1	1	2	2	3	3	4	4	5
78	8921	8927	8932	8938	8943	8949	8954	8960	8965	8971	1	1	2	2	3	3	4	5	5
79	8976	8982	8987	8993	8998	9004	9009	9015	9020	9025	1	1	2	2	3	3	4	4	5
80	9031	9036	9042	9047	9053	9058	9063	9069	9074	9079	1	1	2	2	3	3	4	4	5
81	9085	9090	9096	9101	9106	9112	9117	9122	9128	9133	1	1	2	2	3	3	4	4	5
82	9138	9143	9149	9154	9159	9165	9170	9175	9180	9186	1	1	2	2	3	3	4	4	5
83	9191	9196	9201	9206	9212	9217	9222	9227	9232	9238	1	1	2	2	3	3	4	4	5
84	9243	9248	9253	9258	9263	9269	9274	9279	9284	9289	1	1	2	2	3	3	4	4	5
85	9294	9299	9304	9309	9315	9320	9325	9330	9335	9340	1	1	2	2	3	3	4	4	5
86	9345	9350	9355	9360	9365	9370	9375	9380	9385	9390	1	1	2	2	3	3	4	4	5
87	9395	9400	9405	9410	9415	9420	9425	9430	9435	9440	0	1	1	2	2	3	3	4	4
88	9445	9450	9455	9460	9465	9469	9474	9479	9484	9489	0	1	1	2	2	3	3	4	4
89	9494	9499	9504	9509	9513	9518	9523	9528	9533	9538	0	1	1	2	2	3	3	4	4
90	9542	9547	9552	9557	9562	9566	9571	9576	9581	9586	0	1	1	2	2	3	3	4	4
91	9590	9595	9600	9605	9609	9614	9619	9624	9628	9633	0	1	1	2	2	3	3	4	4
92	9638	9643	9647	9652	9657	9661	9666	9671	9675	9680	0	1	1	2	2	3	3	4	4
93	9685	9689	9694	9699	9703	9708	9713	9717	9722	9727	0	1	1	2	2	3	3	4	4
94	9731	9736	9741	9745	9750	9754	9759	9763	9768	9773	0	1	1	2	2	3	3	4	4
95	9777	9782	9786	9791	9795	9800	9805	9809	9814	9818	0	1	1	2	2	3	3	4	4
96	9823	9827	9832	9836	9841	9845	9850	9854	9859	9863	0	1	1	2	2	3	3	4	4
97	9868	9872	9877	9881	9886	9890	9894	9899	9903	9908	0	1	1	2	2	3	3	4	4
98	9912	9917	9921	9926	9930	9934	9939	9943	9948	9952	0	1	1	2	2	3	3	4	4
99	9956	9961	9965	9969	9974	9978	9983	9987	9991	9996	0	1	1	2	2	3	3	3	4

ANTILOGARITHMS.

	0	1	2	3	4	5	6	7	8	9	1	2	3	4	5	6	7	8	9
·00	1000	1002	1005	1007	1009	1012	1014	1016	1019	1021	0	0	1	1	1	1	2	2	2
·01	1023	1026	1028	1030	1033	1035	1038	1040	1042	1045	0	0	1	1	1	1	2	2	2
·02	1047	1050	1052	1054	1057	1059	1062	1064	1067	1069	0	0	1	1	1	1	2	2	2
·03	1072	1074	1076	1079	1081	1084	1086	1089	1091	1094	0	0	1	1	1	1	2	2	2
·04	1096	1099	1102	1104	1107	1109	1112	1114	1117	1119	0	1	1	1	1	2	2	2	2
·05	1122	1125	1127	1130	1132	1135	1138	1140	1143	1146	0	1	1	1	1	2	2	2	2
·06	1148	1151	1153	1156	1159	1161	1164	1167	1169	1172	0	1	1	1	1	2	2	2	2
·07	1175	1178	1180	1183	1186	1189	1191	1194	1197	1199	0	1	1	1	1	2	2	2	2
·08	1202	1205	1208	1211	1213	1216	1219	1222	1225	1227	0	1	1	1	1	2	2	2	3
·09	1230	1233	1236	1239	1242	1245	1247	1250	1253	1256	0	1	1	1	1	2	2	2	3
·10	1259	1262	1265	1268	1271	1274	1276	1279	1282	1285	0	1	1	1	1	2	2	2	3
·11	1288	1291	1294	1297	1300	1303	1306	1309	1312	1315	0	1	1	1	2	2	2	2	3
·12	1318	1321	1324	1327	1330	1334	1337	1340	1343	1346	0	1	1	1	2	2	2	2	3
·13	1349	1352	1355	1358	1361	1365	1368	1371	1374	1377	0	1	1	1	2	2	2	3	3
·14	1380	1384	1387	1390	1393	1396	1400	1403	1406	1409	0	1	1	1	2	2	2	3	3
·15	1413	1416	1419	1422	1426	1429	1432	1435	1439	1442	0	1	1	1	2	2	2	3	3
·16	1445	1449	1452	1455	1459	1462	1466	1469	1472	1476	0	1	1	1	2	2	2	3	3
·17	1479	1483	1486	1489	1493	1496	1500	1503	1507	1510	0	1	1	1	2	2	2	3	3
·18	1514	1517	1521	1524	1528	1531	1535	1538	1542	1545	0	1	1	1	2	2	2	3	3
·19	1549	1552	1556	1560	1563	1567	1570	1574	1578	1581	0	1	1	1	2	2	3	3	3
·20	1585	1589	1592	1596	1600	1603	1607	1611	1614	1618	0	1	1	1	2	2	3	3	3
·21	1622	1626	1629	1633	1637	1641	1644	1648	1652	1656	0	1	1	2	2	2	3	3	3
·22	1660	1663	1667	1671	1675	1679	1683	1687	1690	1694	0	1	1	2	2	2	3	3	3
·23	1698	1702	1706	1710	1714	1718	1722	1726	1730	1734	0	1	1	2	2	2	3	3	4
·24	1738	1742	1746	1750	1754	1758	1762	1766	1770	1774	0	1	1	2	2	2	3	3	4
·25	1778	1782	1786	1791	1795	1799	1803	1807	1811	1816	0	1	1	2	2	2	3	3	4
·26	1820	1824	1828	1832	1837	1841	1845	1849	1854	1858	0	1	1	2	2	3	3	3	4
·27	1862	1866	1871	1875	1879	1884	1888	1892	1897	1901	0	1	1	2	2	3	3	3	4
·28	1905	1910	1914	1919	1923	1928	1932	1936	1941	1945	0	1	1	2	2	3	3	4	4
·29	1950	1954	1959	1963	1968	1972	1977	1982	1986	1991	0	1	1	2	2	3	3	4	4
·30	1995	2000	2004	2009	2014	2018	2023	2028	2032	2037	0	1	1	2	2	3	3	4	4
·31	2042	2046	2051	2056	2061	2065	2070	2075	2080	2084	0	1	1	2	2	3	3	4	4
·32	2089	2094	2099	2104	2109	2113	2118	2123	2128	2133	0	1	1	2	2	3	3	4	4
·33	2138	2143	2148	2153	2158	2163	2168	2173	2178	2183	0	1	1	2	2	3	3	4	4
·34	2188	2193	2198	2203	2208	2213	2218	2223	2228	2234	1	1	2	2	3	3	4	4	5
·35	2239	2244	2249	2254	2259	2265	2270	2275	2280	2286	1	1	2	2	3	3	4	4	5
·36	2291	2296	2301	2307	2312	2317	2323	2328	2333	2339	1	1	2	2	3	3	4	4	5
·37	2344	2350	2355	2360	2366	2371	2377	2382	2388	2393	1	1	2	2	3	3	4	4	5
·38	2399	2404	2410	2415	2421	2427	2432	2438	2443	2449	1	1	2	2	3	3	4	4	5
·39	2455	2460	2466	2472	2477	2483	2489	2495	2500	2506	1	1	2	2	3	3	4	5	5
·40	2512	2518	2523	2529	2535	2541	2547	2553	2559	2564	1	1	2	2	3	4	4	5	5
·41	2570	2576	2582	2588	2594	2600	2606	2612	2618	2624	1	1	2	2	3	4	4	5	5
·42	2630	2636	2642	2649	2655	2661	2667	2673	2679	2685	1	1	2	2	3	4	4	5	6
·43	2692	2698	2704	2710	2716	2723	2729	2735	2742	2748	1	1	2	3	3	4	4	5	6
·44	2754	2761	2767	2773	2780	2786	2793	2799	2805	2812	1	1	2	3	3	4	4	5	6
·45	2818	2825	2831	2838	2844	2851	2858	2864	2871	2877	1	1	2	3	3	4	5	5	6
·46	2884	2891	2897	2904	2911	2917	2924	2931	2938	2944	1	1	2	3	3	4	5	5	6
·47	2951	2958	2965	2972	2979	2985	2992	2999	3006	3013	1	1	2	3	3	4	5	5	6
·48	3020	3027	3034	3041	3048	3055	3062	3069	3076	3083	1	1	2	3	4	4	5	6	6
·49	3090	3097	3105	3112	3119	3126	3133	3141	3148	3155	1	1	2	3	4	4	5	6	6

ANTILOGARITHMS.

	0	1	2	3	4	5	6	7	8	9	1	2	3	4	5	6	7	8	9
·50	3162	3170	3177	3184	3192	3199	3206	3214	3221	3228	1	1	2	3	4	4	5	6	7
·51	3236	3243	3251	3258	3266	3273	3281	3289	3296	3304	1	2	2	3	4	5	5	6	7
·52	3311	3319	3327	3334	3342	3350	3357	3365	3373	3381	1	2	2	3	4	5	5	6	7
·53	3388	3396	3404	3412	3420	3428	3436	3443	3451	3459	1	2	2	3	4	5	6	6	7
·54	3467	3475	3483	3491	3499	3508	3516	3524	3532	3540	1	2	2	3	4	5	6	6	7
·55	3548	3556	3565	3573	3581	3589	3597	3606	3614	3622	1	2	2	3	4	5	6	7	7
·56	3631	3639	3648	3656	3664	3673	3681	3690	3698	3707	1	2	3	3	4	5	6	7	8
·57	3715	3724	3733	3741	3750	3758	3767	3776	3784	3793	1	2	3	3	4	5	6	7	8
·58	3802	3811	3819	3828	3837	3846	3855	3864	3873	3882	1	2	3	4	4	5	6	7	8
·59	3890	3899	3908	3917	3926	3936	3945	3954	3963	3972	1	2	3	4	5	5	6	7	8
·60	3981	3990	3999	4009	4018	4027	4036	4046	4055	4064	1	2	3	4	5	6	6	7	8
·61	4074	4083	4093	4102	4111	4121	4130	4140	4150	4159	1	2	3	4	5	6	7	8	9
·62	4169	4178	4188	4198	4207	4217	4227	4236	4246	4256	1	2	3	4	5	6	7	8	9
·63	4266	4276	4285	4295	4305	4315	4325	4335	4345	4355	1	2	3	4	5	6	7	8	9
·64	4365	4375	4385	4395	4406	4416	4426	4436	4446	4457	1	2	3	4	5	7	7	8	9
·65	4467	4477	4487	4498	4508	4519	4529	4539	4550	4560	1	2	3	4	5	6	7	8	9
·66	4571	4581	4592	4603	4613	4624	4634	4645	4656	4667	1	2	3	4	5	6	7	9	10
·67	4677	4688	4699	4710	4721	4732	4742	4753	4764	4775	1	2	3	4	5	7	8	9	10
·68	4786	4797	4808	4819	4831	4842	4853	4864	4875	4887	1	2	3	4	6	7	8	9	10
·69	4898	4909	4920	4932	4943	4955	4966	4977	4989	5000	1	2	3	5	6	7	8	9	10
·70	5012	5023	5035	5047	5058	5070	5082	5093	5105	5117	1	2	4	5	6	7	8	9	11
·71	5129	5140	5152	5164	5176	5188	5200	5212	5224	5236	1	2	4	5	6	7	8	10	11
·72	5248	5260	5272	5284	5297	5309	5321	5333	5346	5358	1	2	4	5	6	7	9	10	11
·73	5370	5383	5395	5408	5420	5433	5445	5458	5470	5483	1	3	4	5	6	8	9	10	11
·74	5495	5508	5521	5534	5546	5559	5572	5585	5598	5610	1	3	4	5	6	8	9	10	12
·75	5623	5636	5649	5662	5675	5689	5702	5715	5728	5741	1	3	4	5	7	8	9	10	12
·76	5754	5768	5781	5794	5808	5821	5834	5848	5861	5875	1	3	4	5	7	8	9	11	12
·77	5888	5902	5916	5929	5943	5957	5970	5984	5998	6012	1	3	4	5	7	8	10	11	12
·78	6026	6039	6053	6067	6081	6095	6109	6124	6138	6152	1	3	4	6	7	8	10	11	13
·79	6166	6180	6194	6209	6223	6237	6252	6266	6281	6295	1	3	4	6	7	9	10	11	13
·80	6310	6324	6339	6353	6368	6383	6397	6412	6427	6442	1	3	4	6	7	9	10	12	13
·81	6457	6471	6486	6501	6516	6531	6546	6561	6577	6592	2	3	5	6	8	9	11	12	14
·82	6607	6622	6637	6653	6668	6683	6699	6714	6730	6745	2	3	5	6	8	9	11	12	14
·83	6761	6776	6792	6808	6823	6839	6855	6871	6887	6902	2	3	5	6	8	9	11	13	14
·84	6918	6934	6950	6966	6982	6998	7015	7031	7047	7063	2	3	5	6	8	10	11	13	15
·85	7079	7096	7112	7129	7145	7161	7178	7194	7211	7228	2	3	5	7	8	10	12	13	15
·86	7244	7261	7278	7295	7311	7328	7345	7362	7379	7396	2	3	5	7	8	10	12	13	15
·87	7413	7430	7447	7464	7482	7499	7516	7534	7551	7568	2	3	5	7	9	10	12	14	16
·88	7586	7603	7621	7638	7656	7674	7691	7709	7727	7745	2	4	5	7	9	11	12	14	16
·89	7762	7780	7798	7816	7834	7852	7870	7889	7907	7925	2	4	5	7	9	11	13	14	16
·90	7943	7962	7980	7998	8017	8035	8054	8072	8091	8110	2	4	6	7	9	11	13	15	17
·91	8128	8147	8166	8185	8204	8222	8241	8260	8279	8299	2	4	6	8	9	11	13	15	17
·92	8318	8337	8356	8375	8395	8414	8433	8453	8472	8492	2	4	6	8	10	12	14	15	17
·93	8511	8531	8551	8570	8590	8610	8630	8650	8670	8690	2	4	6	8	10	12	14	16	18
·94	8710	8730	8750	8770	8790	8810	8831	8851	8872	8892	2	4	6	8	10	12	14	16	18
·95	8913	8933	8954	8974	8995	9016	9036	9057	9078	9099	2	4	6	8	10	12	15	17	19
·96	9120	9141	9162	9183	9204	9226	9247	9268	9290	9311	2	4	6	8	11	13	15	17	19
·97	9333	9354	9376	9397	9419	9441	9462	9484	9506	9528	2	4	7	9	11	13	15	17	20
·98	9550	9572	9594	9616	9638	9661	9683	9705	9727	9750	2	4	7	9	11	13	16	18	20
·99	9772	9795	9817	9840	9863	9886	9908	9931	9954	9977	2	5	7	9	11	14	16	18	20

Angle.	Radians.	Sine.	Tangent.	Co-tangent.	Cosine		
0°	0	·0	0	∞	1	1·5708	90°
1	·0175	·0175	·0175	57·2900	·9998	1·5533	89
2	·0349	·0349	·0349	28·6363	·9994	1·5359	88
3	·0524	·0523	·0524	19·0811	·9986	1·5184	87
4	·0698	·0698	·0699	14·3006	·9976	1·5010	86
5	·0873	·0872	·0875	11·4301	·9962	1·4836	85
6	·1047	·1045	·1051	9·5144	·9945	1·4661	84
7	·1222	·1219	·1228	8·1443	·9925	1·4486	83
8	·1396	·1392	·1405	7·1154	·9903	1·4312	82
9	·1571	·1564	·1584	6·3138	·9877	1·4137	81
10	·1745	·1736	·1763	5·6713	·9848	1·3963	80
11	·1920	·1908	1944	5·1446	·9816	1·3788	79
12	·2094	·2079	·2126	4·7046	·9781	1·3614	78
13	·2269	·2250	·2309	4·3315	·9744	1·3439	77
14	·2443	·2419	·2493	4·0108	·9703	1·3265	76
15	·2618	·2588	2679	3·7321	·9659	1·3090	75
16	·2793	·2756	·2867	3·4874	·9613	1·2915	74
17	·2967	2924	·3057	3·2709	·9563	1·2741	73
18	·3142	·3090	·3249	3·0777	·9511	1·2566	72
19	·3316	·3256	·3443	2·9042	·9455	1·2392	71
20	·3491	·3420	·3640	2·7475	·9397	1·2217	70
21	·3665	·3584	·3839	2·6051	·9336	1·2043	69
22	·3840	·3746	·4040	2·4751	·9272	1·1868	68
23	·4014	·3907	·4245	2·3559	·9205	1·1694	67
24	·4189	·4067	·4452	2·2460	·9135	1·1519	66
25	·4363	·4226	·4663	2·1445	·9063	1·1345	65
26	·4538	·4384	4877	2·0503	·8988	1·1170	64
27	·4712	·4540	·5095	1·9626	·8910	1·0996	63
28	·4887	·4695	·5317	1·8807	·8830	1·0821	62
29	·5061	·4848	·5543	1·8040	·8746	1·0647	61
30	·5236	·5000	·5774	1·7321	·8660	1·0472	60
31	·5411	·5150	·6009	1·6643	·8572	1·0297	59
32	·5585	·5299	·6249	1·6003	·8480	1·0123	58
33	·5760	·5446	·6494	1·5399	·8387	·9948	57
34	·5934	·5592	·6745	1·4826	·8290	·9774	56
35	·6109	·5736	·7002	1·4281	·8192	·9599	55
36	·6283	·5878	·7265	1·3764	·8090	·9425	54
37	·6458	·6018	·7536	1·3270	·7986	·9250	53
38	·6632	·6157	·7813	1·2799	·7880	·9076	52
39	·6807	·6293	·8098	1·2349	·7771	·8901	51
40	·6981	·6428	·8391	1·1918	·7660	·8727	50
41	·7156	·6561	·8693	1·1504	·7547	·8552	49
42	·7330	·6691	·9004	1·1106	·7431	·8378	48
43	·7505	·6820	·9325	1·0724	·7314	·8203	47
44	·7679	·6947	·9657	1·0355	·7193	·8029	46
45	·7854	·7071	1·0000	1·0000	·7071	·7854	45
		Cosine	Co-tangent	Tangent	Sine	Radians	Angle

INDEX.

A

PAGE
Absolute motion, . . . 1
,, unit of force, . . 32
Acceleration, ... 5, 12
,, —Angular, . . 12
,, —Composition and resolution of, . 15
,, —Total, . . 16
Accumulator—Hydraulic, 367, 381, 389.
,, ,, —Differential, . 384
,, ,, —Steam, 386
Air pump, ... 341
Ammonia as a refrigerating agent, ... 462
Angel of twist, . . . 267
Angular acceleration, . . 12
,, velocity, . . . 10
Area—Centre of an, . . . 220
,, —Moment of inertia of an, 230
Arrol-Foulis retort charging machine, ... 390
Average velocity, . . . 4

B

Balanced jib crane, . . 188
Balancing machinery, . . 123
Beam fixed at one end—
Loaded at other, . . . 273
,, uniformly, . . 274
Supported at other, . . 308
Beam fixed at both ends—
Loaded at centre, . . . 309
,, uniformly, . . 312
Beam supported at both ends—
Loaded at centre, . . . 275
,, anywhere, . . 277
,, uniformly, . 225, 278
With several loads, . . 279
Beam supported at three points, 308
PAGE
Beam—Resultant of loads on a, 207
,, with travelling loads, 284, 286, 289
Curvature and deflection of, . 304
Floating, ... 282
Resistance to flexure, . . 294
Strength of, . . . 272, 314
Bear—Hydraulic, . . . 364
Bending and twisting cambined, 262
,, moment, . . 222, 273
,, ,, diagram, . 223
,, ,, —Equivalent, 265
Bernouilli's theorem, . . 400
Blower—Roots', . . . 354
Body rotating about an axis, . 10
Bolman truss, ... 209
Bow's notation, . . . 134
Bowstring truss, . . . 163
Bramah's hydraulic press, . 355
Breast-wheel, ... 430
Brown's steam accumulator, . 386

C

Cantilever loaded at end, . 273
,, ,, several places, 227
,, ,, uniformly, 224, 274
Capstan—Hydraulic, . 373, 375
Carbon dioxide as a refrigerating agent, . . 445
,, ,, refrigerating plant, . . 460
Cast-iron girder, . . . 301
Centre of gravity of area, . 229
Centrifugal force, . . . 80
,, ,, —Pressure due to, . 417
,, ,, —Straining action due to, 83

PAGE
Centrifugal machine—Weston's, 124
,, pumps, ... 450
Chains and wires—Strength of suspended, ... 249
Charging machine for gas retorts, 390
Circle—Moment of inertia of, . 62
Circular motion—Hodograph of, 19
Circulating pumps, ... 347
Clack mill, ... 433
Classification of frames, . . 132
Coefficient of elasticity, . . 242
,, resilience, . . 243
Cold—Transmission of, . . 470
Combined bending and twisting, 262
,, shearing and direct stresses, . . 263
Common pendulum governor, . 99
Composition of accelerations, . 15
,, velocities, . 13
Compressor for ammonia, . 465
Conditions of equilibrium, . 133
Conical pendulum, ... 95
Continuous delivery pumps, . 345
Cooling machinery. *See* Refrigerating.
Crane—Balanced jib, . . 188
,, —Common jib, . . 185
,, —Derrick or Scotch, 189, 203
,, —Foundry, ... 190
,, —Hydraulic, ... 369
,, —Overhead travelling, . 287
,, —Sheer legs, ... 192
,, —130-ton steam, . . 196
,, —Wharf, ... 182
Crossed-arm governor, . . 100
Current meter, ... 415
Curvature of beams, . . 304
Cylinders—Strength of thick, . 247
,, ,, thin, . 245

D

Deficient frames, . . 133, 170
Deflection of beams, . . 304
De la Vergne's refrigerator, . 463
Derrick crane, . . . 189, 203
,, pole, ... 194
Diagram—Bending moment, . 222
,, —Stress, ... 140
,, for increasing velocity, 8
,, for uniform velocity, . 7
,, of work done by falling weight, ... 50
PAGE
Diagram of work done by compressing spring, ... 49
Differential accumulator, . . 384
Direct-acting steam pump, . 389
Distributed travelling load, . 289
Double inclined plane, . . 35

E

Ejectors, ... 402
Elasticity—Coefficient of, . 242
,, —Limit of, . . 242
,, —Modulus of, . . 242
Elliott's current meter, . . 414
Energy, ... 43
,, equations, . . . 46
,, —Kinetic, . . 44, 45
,, lost by impact, . . 421
,, of a rotating body, . 56
,, ,, flowing water, . . 400
,, ,, flywheels, . . . 74
,, ,, hydraulic accumulator, 383
,, ,, still water, . . 336
,, —Potential. . . . 44
Engine mechanism, . . . 232
Engines—Governing of, . . 92
,, —Pumping, . . . 381
Equilibrium—Conditions of, . 133
Equivalent bending and twisting moments, ... 265

F

Fairbairn's breast-wheel, . 430
,, improvement, . 432
Figures—Reciprocal, . . 139
Fink truss, ... 209, 235
Finnieston Quay—130-ton crane at, ... 196
Firm frames, . . 133, 143, 147
,, ,, with Mansard outline, . . . 147
,, ,, with quadrilateral part, . . 146
,, quadrilateral frame, . 143
,, triangular frame, . . 145
Flanging Press, . . . 358
Flexure of beams, . . . 294
Floating beams, . . . 282
Fluid—Definition of, . . 324
,, —Pressure of, . . . 326

PAGE
Fluid—Transmission of pressure by a, ... 326
,, pressure—Examples on, . 328
Fluids—Viscosity of, . . . 325
Fly-press, ... 69
Flywheels, ... 122
,, —Energy of, . 70, 74
,, —Stress in, . . . 85
Force—Centripetal and centrifugal, ... 80
,, pumps, ... 342, 347
,, —Shearing, . . . 224, 273
,, —Stress due to centrifugal, 83
,, —Units of, ... 32
Foulis' withdrawing machine, . 394
Foundry crane, ... 190
Framed Structure, ... 132
Frame—Quadrilateral, . . . 143
,, —Queen post, . . . 171
,, —Triangular, . . . 136
,, with load at internal joint, 159
Frames—Classification of, . 132
,, —Deficient, . . 133, 170
,, —Firm, . 133, 143, 147
,, —Redundant, . . . 133
,, —Substituted, . . . 150
Free Surface, ... 326
French Truss, ... 161
Funicular polygon, ... 206

G

Galloway's parabolic governor, 102
Gas Works—Labour-saving appliances, ... 380
Gases, ... 324
Gauge notch, ... 409-412
Girard turbine, ... 438
,, ,, —Günther's, . 438
Girder—Lattice, 216, 218, 221, 236
,, —Linville or N, . . . 215
,, —Warren, ... 215
Girders—Cast-iron, ... 301
,, —Strength of, . . . 272
,, —Thin wrought-iron, . 303
Governing of engines, . 92, 114
,, ,, by throttling and expansion, 114
Governor—Common pendulum, 99
,, —Crossed-arm, . . . 100
,, —Galloway's parabolic, 102
,, —Hartnell spring, . 108
PAGE
Governor—Inertia, ... 120
,, —Knowles' supplemental, . . 120
,, —M'Farlane's safety, 110
,, —Otto gas engine, . 122
,, —Pickering, . . . 114
,, —Porter's loaded, . 103
,, —Proell's spring, . 108
,, —Relay, ... 117
,, —Shaft, ... 118
,, —Stockport gas engine, 121
,, —Watt's, ... 93
,, —Willans' spring, . 110
Graphic methods of representing velocities, &c , . 7
,, statics, ... 132
Gravitation units of force, . 32
Gravity—Motion due to, . . 9
Günther's Girard turbine, . 438
,, Jonval turbine, . 443
,, turbine governor, . 444
Gyration—Tables of radii of, . 67

H

Hall's refrigerator, ... 460
Hartnell's spring governor, . 109
Head of fluid, ... 326
,, —Measurement of, . 413
Helical seams, ... 246
Hodograph, ... 17
,, for circular motion, 19
Horse-power of a stream, . 415
Hydraulic accumulator, . 367, 389
,, ,, —Differential, 384
,, ,, —Steam, . 386
,, bear, ... 364
,, capstan, . . 373, 375
,, cranes, . . 369-374
,, flanging press, . . 358
,, jack, ... 360
,, lead-covering cable press, . . . 365
,, mean depth, . . . 424
,, motors, ... 428
,, press—Bramah's, . 355
,, ram, ... 403
,, stoking machinery, 390, 394
Hydraulics, ... 324
Hydrokinetics, ... 324
Hydrostatics, ... 324

PAGE

I

IMMERSED surface—Pressure on, 327
Inclined plane—Body rolling down, . 72
,, ,, —Double, . 35
,, ,, —Motion down, 20
Inertia governors, . . . 120
,, —Moment of, . 56, 297
,, ,, —Method of calculating, 60
,, ,, of area, . . 230
,, ,, ,, circle, . 62
,, ,, ,, rectangle, . 60
,, ,, ,, similar bodies, 79
,, ,, ,, sphere, . 64
Injectors, ... 402
Intensity of stress, . . . 240
Iron king post truss, . . 170

J

JACK—Hydraulic, . . . 360
Jet—Motion produced by, . 419
,, pumps, ... 402
Jib crane, ... 185
,, —Balanced, . . 188
Jigger hoist, ... 372
Jonval turbine, ... 443

K

KIND of stress in a bar, . . 141
Kinetic energy, ... 44
King post truss, . . 150, 170
Knowles' supplemental governor, 102

L

LABOUR-SAVING appliances in gas works, ... 380
Lattice girder, 216, 218, 221, 236
,, ,, of five bays, . 218
,, ,, loaded at top joints, . . 220
Laws of motion—Newton's, . 31
Lead covering cable press, . 365
Legs—Sheer, ... 192
Lettering—Bow's method of, . 134
Limit of elasticity, . . . 242
Linde refrigerator, . . . 468

PAGE

Linear motion—Formulæ for, . 9
Line of loads, ... 144
Linville girder, ... 215
Liquids, ... 324
Live load, ... 244
Load at internal joint of frame, 158
,, —Distributed travelling, 289
,, —Live, ... 244
,, —Single travelling, . . 284
,, —Two travelling at a fixed distance apart, . . 286
Loaded governor, . . 103, 108

M

MACFARLANE'S safety governor, 110
Machinery—Balancing, . . 123
Machine for charging gas retorts, 390
,, ,, withdrawing ,, 394
,, —Refrigerating, . 456
,, ,, —Hall's, 460
,, ,, —De La Vergne's, 463
,, ,, —Linde, 468
,, —Weston's centrifugal, 124
Mansard roof frame, . . 147
Materials—Strength of, . . 317
Mechanism—Engine, . . 232
Modified French truss, . . 161
Modulus of elasticity, . . 242
,, resilience, . . 243
,, sections, . . 318
Moment—Bending, . . 222, 273
,, of inertia, . . 56, 297
,, ,, —Method of calculating, . 60
,, ,, of area, . . 230
,, ,, ,, circle, . 62
,, ,, ,, rectangle, . 60
,, ,, ,, similar bodies, 79
,, ,, ,, sphere, . 64
,, ,, —Table of, . 318
,, —Twisting, . . 256
Momentum of a body, . . 30
Motion—Definition of, . . 1
,, due to gravity, . . 9
,, —General formulæ for linear, . . . 9
,, in a circle, . . . 19
,, —Newton's laws of, . 31
,, on a double inclined plane, 35
,, produced by a jet, . 419
,, —Quantity of, . . 30

PAGE
Motion—Vortex, . . . 415
Motors—Hydraulic, . . 428

N

NEWTON'S laws of motion, . 31
Normal and tangential stresses, 241
Notation—Bow's, . . . 134

O

OTTO gas engine governor, . 122
Overhead travelling crane, . 287
Overshot water wheel, . . 429

P

PARABOLIC governor, . . 102
Parallelogram of velocities, . 13
Pelton wheel, ... 434
Pendulum—Conical, . . 95
,, governor, . . 99
Pickering governor, . . . 114
Pipes—Resistance of, to flow of fluids, ... 423
Polygon of velocities, . . 14
,, —Funicular, . . 206
Porter's loaded governor, . 103
Potential energy, . . . 44
Pressure—Centre of, . . 332
,, column, . . . 327
,, due to centrifugal force, 417
,, —Examples on fluid, . 328
,, of a fluid, . . . 326
,, on an immersed surface, 327
,, —Reduction of, round an orifice, . . 421
,, —Transmission of, by a fluid, . . . 326
Proell's spring governor, . . 109
Pulsometer pumps, . . . 351
Pumping engines, . . . 381
Pumps—Air, ... 341
,, —Centrifugal, . . 450
,, —Force, . . . 342
,, —Jet, ... 402
,, —Pulsometer, . . 351
,, —Steam, . . 348, 389
,, —Suction, . . . 337

PAGE
Q

QUANTITY of motion, . . 30
Quadrilateral frame, . . 143
Queen post frame, . . . 171

R

RADII of gyration—Tables of, . 67
Ram—Hydraulic, . . . 403
Reactions on a beam, . . 206
Reciprocal figures, . . . 139
,, of a point, . . 137
Rectangle—Moment of inertia of, 60
Redundant frames, . . . 133
Refrigerating agents—
Carbon dioxide, . . . 455
Anhydrous ammonia, . . 462
Refrigerating apparatus, . . 455
,, —Elementary, . 455
,, machine—De la Vergne's, 463
,, ,, —Hall's, 460
,, ,, —Linde, 468
,, ,, —Simple, 456
Refrigeration, ... 454
,, —Methods of transmitting cold, 470
Relative motion, . . . 1
Relays, ... 116
Resilience, ... 243
,, —Coefficient of, . 243
,, —Modulus of. . . 243
Resistance of beams to flexure, 294
,, ,, pipes to flow of fluids, . . 423
Resolution of accelerations, . 15
,, ,, velocities, . . 13
Resultant of loads on a beam. . 207
Right-angled strut truss, . 153, 168
Rings—Shrunk, . . . 244
Rolling down a plane, . . 72
Roof truss, ... 156
Roots' blower, ... 354
Rotating body, . . . 10
,, ,, —Energy of, 56, 68
Rule for kind of stress, . . 142

S

SAFETY governor, . . . 110
Scotch derrick crane, . 189, 203

PAGE
Seams—Helical, ... 246
Shaft governors, ... 181
Shafts—Stiffness of, . . . 267
,, subject to both bending and twisting, . . 262
,, —Torsional strength of, . 256
Shear and tension combined, . 263
Shearing force, . . . 224, 273
,, stress, ... 257
,, ,, on planes at right angles, . 263
Sheer legs, ... 192
Shrunk rings, ... 244
Sphere—Moment of inertia of, . 64
Spring loaded governor, . 108, 110
,, —Work done in compressing, 49
Statics—Graphic, ... 132
Steam crane—130-ton, . . . 196
,, ejector, ... 402
,, loaded accumulator, . 386
,, pump, ... 348, 389
Stiffness of beams, ... 314
,, ,, shafts, ... 267
Stockport gas engine governor, 121
Stoking machinery for gas works, ... 390, 394
Strain, ... 242
Straining actions due to centrifugal force, ... 83
Stream—Horse-power of, . 415
,, —Measurement of a flowing, ... 409-415
Strength of beams and girders, 272, 314
,, ,, materials (table), . 317
,, ,, shafts under torsion, 256
,, ,, shafts under torsion and bending, . 262
,, ,, suspended chains and wires, ... 249
,, ,, thick cylinders, . 247
,, ,, thin cylinders, . 245
Stress, ... 240
,, diagram, ... 140
,, in a bar—Kind of, . . 141
,, —Intensity of, . . . 240
Stresses—Normal and tangential, 241
Structure—Framed, . . . 132
Strut, ... 139
,, truss—Right angled, 153, 168
Substituted frames, ... 150
Suction pump, ... 337
Sudden pull, ... 244
Supplemental governor, . . 120
Suspended chains and wires, . 249

T

TABLES—
Moments of inertia and moduli of sections, . . 318
Radii of gyration, . . . 67
Strength of materials, . . 317
Strength and stiffness of beams, ... 314
Tangential and normal stresses, 241
Tension and shear combined, . 263
Thick cylinders, ... 247
Thin cylinders, ... 245
,, wrought-iron girders, . 303
Thomson's triangular gauge notch, . . . 412
,, vortex turbine, . 445
Throttling—Governing by, . 114
Tie, ... 139
Torsional strength of shafts, . 256
Total acceleration, ... 16
Transmission of cold, . . . 470
Trapezoidal truss, ... 210
Travelling loads—Concentrated, 284
,, ,, —Distributed, . 289
,, ,, —Two at a distance apart, 286
Triangle of velocities, . . . 14
Triangular frame, . 136, 145, 213
Tripod, ... 201
Truss—Bolman, ... 209
,, —Bowstring, ... 163
,, —Fink, ... 209, 235
,, —French, ... 161
,, —Iron king post, . . 170
,, —King post, . . 150, 170
,, —Right-angled strut, 153, 168
,, —Roof, ... 156
,, —Trapezoidal, . . . 210
Turbine governor—Günther's, . 444
Turbines, ... 437
,, —Girard, ... 437
,, —Jonval, ... 443
,, —Little giant, . . . 447
,, —Thomson's vortex, . 445
Tweddell's differential accumulator, ... 384
Twist—Angle of, ... 267
Twisting combined with bending, 262
,, moment, ... 256
,, ,, —Equivalent, 265
Two loads at a fixed distance apart, ... 286

PAGE

U

UNDERSHOT water-wheels, . 431
Uniform angular velocity, . 11
,, beam on three supports, 308
,, ,, fixed at one end and supported at other, . 308
,, motion in a circle, . 19
,, velocity, . . . 3
,, ,, diagram, . 7
Uniformly loaded beam, 226, 278, 312
,, ,, cantilever, 224, 274
Units of force, ... 32

V

VAPOURS, ... 324
Variable angular velocity, . 12
,, expansion—Governing by, . . . 114
,, velocity, . . . 3
Velocity, ... 2
,, —Angular, . . 10
,, —Average, . . 4
,, diagrams, . . . 7
,, of efflux of water, . 407
,, of point on rolling wheel, 23
Velocities — Composition and resolution of, . . . 13
Viscosity of fluids, . . . 325

PAGE

Vortex—Forced, . . . 416
,, —Free, ... 415
,, motion, ... 415

W

WARREN girder, . . . 215
Water—Energy of still, . . 336
,, —Pressure of, . 326-336
,, —Velocity of efflux and flow of, from a tank, 407
Water-wheel—Overshot, . . 429
,, —Undershot, . 421
Water-wheels—Fairbairn's improvements, ... 432
Watt's governor, . . . 93
,, ,, —Theory of, . 95
Weston's centrifugal machine, . 124
Wharf crane, ... 182
Wheel—Pelton, . . . 434
,, —Velocity of point on rolling, . . . 23
Willans' spring governor, . 110
Wires—Strength of suspended, 249
Withdrawing machine for gas retorts, ... 394
Work done in stretching a bar, 242
Worthington steam pump, . 348
Wrought-iron girders, . . 303

Y

YIELDINGNESS, . . . 175

BELL AND BAIN, LIMITED, PRINTERS, GLASGOW.

A SELECTION

FROM THE

SCIENTIFIC AND TECHNICAL WORKS

PUBLISHED BY

CHARLES GRIFFIN & COMPANY, LIMITED.

(Being Sections 4-10 from Messrs. Griffin's "General Catalogue.")



MESSRS. CHARLES GRIFFIN & COMPANY'S PUBLICATIONS may be obtained through any Bookseller in the United Kingdom, or will be sent Post-free on receipt of a remittance to cover published price. To prevent delay, Orders should be accompanied by Cheque or Postal Order crossed "SMITH, PAYNE & SMITHS."

*** *For INDEX, see next page.*

☞ **MEDICAL, and GENERAL CATALOGUES forwarded Post-free on Application.**

LONDON:
EXETER STREET, STRAND.

INDEX.

PAGE

ALLINGHAM (W.), Navigation, 45, 47
—— Meteorology, ... 45
ANGLIN (S.), Design of Structures, . 26
ARCHBUTT & DEELEY, Lubricants and Lubrication, ... 80
BARKER (D. WILSON-), Navigation and Seamanship, ... 45, 47
BERINGER (J. J. & C.), Assaying, . 66
BILES (Prof. J. H.), Construction of Ships, ... 38
BLACKMORE (E.), British Mercantile Marine, ... 45-46
BLOUNT (B.) and BLOXAM (A. G.), Chemistry for Engineers and Manufacturers, ... 27, 71
BLYTH (A. Wynter), Foods and Poisons, 72
BORCHERS (Dr.), Electric Smelting, 67
BROTHERS (A.), Photography, . . 73
BROUGH (B. H.), Mine-Surveying, . 59
BROWNE (W. R.), Works by, . . 27
BRUCE (Robt.), Food Supply, . . 55
BUCK (R. C.), Algebra and Trigonometry, ... 45, 46
BUTTERFIELD (W. J. A.), Gas Manufacture, ... 74
CASTELL-EVANS (Prof.), Tables for Chemists, ... 75
COLE (Prof G. A. J.), Practical Geology, 53
—— Open Air Studies in Geology, . . 86
COLE (W. H.), Light Railways, . . 41
COLLINS, (H. F.), Metallurgy of Lead and Silver, ... 65
COX (S. H.), Prospecting for Minerals, 55
CRIMP (W. S.), Sewage Disposal Works, 28
DONKIN (Bryan), Gas and Oil Engines, 29
—— Efficiency of Steam Boilers, . . 29
DUERR (Geo.), Bleaching and Calico-Printing, ... 83
DUPRÉ & HAKE, Manual of Chemistry, 70
ETHERIDGE (R.), Stratigraphical Geology, ... 52
FIDLER (Prof.), Bridge-Construction, 30
FOSTER (Prof. C. le Neve), Ore and Stone Mining, ... 56
—— Elementary Mining, ... 56
GINSBURG (Dr.), Legal Duties of Shipmasters, ... 45, 49
GRIFFIN (J. J.), Chemical Recreations, 75
GRIFFIN'S Electrical Price-Book, . 43
GRIFFIN'S ENGINEERING PUBLICATIONS, ... 25
GRIFFIN'S GEOLOGICAL and METALLURGICAL SERIES, . 51
GRIFFIN'S NAUTICAL SERIES, . . 45
GRIFFIN'S NEW LAND SERIES, 54
GRIFFIN'S CHEMICAL AND TECHNOLOGICAL PUBLICATIONS, ... 69
GURDEN (R.), Traverse Tables, . . 31
GUTTMANN (O.), Blasting, . . . 59
HARBORD (F. W.), Steel, ... 65
HUGHES (H. W.), Coal Mining, . . 57
HURST (Chas.), Valves and Valve-Gearing, ... 31
HURST (G. H.), Painters' Colours, . 76
—— Garment Dyeing and Cleaning . 83
JAMIESON (Prof.), MANUALS, Advanced and Elementary, ... 32
—— Steam Engine, ... 32
—— Applied Mechanics, ... 32
—— Magnetism and Electricity, . . 32
JENKINS (H. C.), Metallurgical Machinery, ... 62
JOHNSON (J. C. F.), Getting Gold, . 55
KNECHT & RAWSON, Dyeing, . . . 81
LAFAR and SALTER, Technical Mycology, ... 79

PAGE

LAWN (J. G.), Mine Accounts, . . 60
LIVERSIDGE (J. G.), Engine-Room Practice, ... 34
MACKENZIE (T.), Mechanics for Sailors, ... 45, 48
M'MILLAN (W. G.), Electro-Metallurgy, 68
—— & BORCHERS, Electric Smelting, 67
MILLAR (W. J.), Latitude and Longitude: How to find them, . . . 45, 48
MORGAN (J. J.), Tables for Quantitative Metallurgical Analysis, . . . 67
MUNRO & JAMIESON'S Electrical Pocket-Book, ... 43
MUNRO (Dr.), Agricultural Chemistry, 75
MUNRO (R. D.), Steam-Boilers, . . 33
—— Kitchen Boiler Explosions, . . 33
NYSTROM'S Pocket-Book for Engineers, 33
PEARCE (W. J.), Painting and Decorating, ... 77
PETTIGREW (W. F.), Manual of the Locomotive, ... 34
PHILLIPS & BAUERMAN, Metallurgy, 61
POYNTING (Prof.), Mean Density of the Earth, ... 44
PRAEGER (R. L.), Open Air Botany, . 86
RANKINE'S Applied Mechanics, . . 35
—— Civil Engineering, ... 35
—— Machinery and Millwork, . . . 35
—— Steam Engine & other Prime Movers, 35
—— Useful Rules and Tables, . . . 36
—— A Mechanical Text-Book, . . . 36
—— Miscellaneous Scientific Papers, . 36
REDGRAVE (G. R.), Cements, . . 76
REDWOOD (Boverton), Petroleum, . . 58
REED (Sir E. J.), Stability of Ships, . 38
REID (Geo., M.D.), Practical Sanitation, 85
RICHMOND (H. D.), Dairy Chemistry, 75
RIDDELL (Dr. Scott), Ambulance Manual, ... 85
ROBERTS-AUSTEN (Prof.), Metallurgy and Alloys, ... 62, 63
ROBINSON (Prof.), Hydraulics, . . 37
ROSE (T. K.), Gold, Metallurgy of, . 64
ROTHWELL, (C. F. Seymour), Textile Printing, ... 82
SCHWACKHÖFER and BROWNE, Fuel and Water, ... 27
SEATON (A. E.), Marine Engineering, 39
SEATON & ROUNTHWAITE, Marine Engineers' Pocket-Book, ... 39
SEELEY (Prof.), Physical Geology, . 52
SEXTON (Prof.), Elementary Metallurgy, ... 66
—— Quantitative & Qualitative Analysis, 70
SHELTON (W. V.), Mechanic's Guide, 36
SMITH, (Johnson), Shipmaster's Medical Help, ... 49
SMITH (Prof. R. H.), Calculus for Engineers, ... 40
—— Measurement Conversions, . . 40
SYKES (Dr. W. J.), Brewing, . . . 78
THOMSON & POYNTING (Profs.) Text-Book of Physics, ... 44
TRAILL (T. W.), Boilers, Land and Marine, ... 41
TURNER (Thos.), Iron, Metallurgy of, 65
WALTON (T.), Know Your Own Ship, 41, 50
WATKINSON (Prof. W. H.), Gas and Oil Engines, ... 42
WELLS (S. H.), Engineering Drawing, 42
WIGLEY (T. B.), Goldsmith and Jeweller's Art, ... 68
WRIGHT (Dr. Alder), Oils and Fats, Soaps and Candles, ... 80
YEAMAN (C. H.), Elec. Measurements, 43
YEAR-BOOK of Scientific Societies, . 84

§§ 4-5. Griffin's Standard Publications

FOR

ENGINEERS, ELECTRICIANS, ARCHITECTS, BUILDERS, NAVAL CONSTRUCTORS, AND SURVEYORS.

		PAGE
Applied Mechanics,	RANKINE, BROWNE, JAMIESON,	35, 27, 32
Civil Engineering,	PROF. RANKINE,	35
Bridge-Construction,	PROF. FIDLER,	30
Design of Structures,	S. ANGLIN,	26
Sewage Disposal Works,	SANTO CRIMP,	28
Traverse Tables,	R. L. GURDEN,	31
Light Railways,	W. H. COLE,	41
Marine Engineering,	A. E. SEATON,	39
Engine-Room Practice,	J. G. LIVERSIDGE,	34
Design and Construction of Ships,	PROF. HARVARD BILES,	38
Stability of Ships,	SIR E. J. REED,	38
The Steam-Engine,	RANKINE, JAMIESON,	35, 32
The Locomotive,	W. F. PETTIGREW,	34
Valves and Valve-Gearing,	CHAS. HURST,	31
Gas, Oil, and Air-Engines,	BRYAN DONKIN,	29
Boilers: Construction,	T. W. TRAILL,	41
,, **Management,**	R. D. MUNRO,	33
,, **Heat Efficiency,**	BRYAN DONKIN,	29
Chemistry for Engineers,	BLOUNT & BLOXAM	27
Fuel and Water (for Steam Users),	SCHWACKHÖFER AND BROWNE,	27
Machinery and Millwork,	PROF. RANKINE,	35
Hydraulic Machinery,	PROF. ROBINSON,	37
Metallurgical Machinery,	H. C. JENKINS,	62
Nautical Series,	Ed. by CAPT. BLACKMORE,	45
Useful Rules and Tables for Engineers, &c.,	PROFS. RANKINE AND JAMIESON,	36
Electrical Pocket-Book,	MUNRO AND JAMIESON,	43
Electrical Price-Book,	H. J. DOWSING,	43
The Calculus for Engineers,	PROF. ROBT. H. SMITH,	40
Graphic Tables for Conversion of Measurements,	PROF. ROBT. H. SMITH,	40
Marine Engineers' Pocket-Book,	SEATON AND ROUNTHWAITE,	39
Nystrom's Pocket-Book,	DENNIS MARKS,	33

THE DESIGN OF STRUCTURES:

A Practical Treatise on the Building of Bridges, Roofs, &c.

BY S. ANGLIN, C.E.,

Master of Engineering, Royal University of Ireland, late Whitworth Scholar, &c.

With very numerous Diagrams, Examples, and Tables.
Large Crown 8vo. Cloth.

SECOND EDITION, *Revised.* 16s.

The leading features in Mr. Anglin's carefully-planned "Design of Structures" may be briefly summarised as follows:—

1. It supplies the want, long felt among Students of Engineering and Architecture, of a concise Text-book on Structures, requiring on the part of the reader a knowledge of ELEMENTARY MATHEMATICS only.

2. The subject of GRAPHIC STATICS has only of recent years been generally applied in this country to determine the Stresses on Framed Structures; and in too many cases this is done without a knowledge of the principles upon which the science is founded. In Mr. Anglin's work the system is explained from FIRST PRINCIPLES, and the Student will find in it a valuable aid in determining the stresses on all irregularly-framed structures.

3. A large number of PRACTICAL EXAMPLES, such as occur in the every-day experience of the Engineer, are given and carefully worked out, some being solved both analytically and graphically, as a guide to the Student.

4. The chapters devoted to the practical side of the subject, the Strength of Joints, Punching, Drilling, Rivetting, and other processes connected with the manufacture of Bridges, Roofs, and Structural work generally, are the result of MANY YEARS' EXPERIENCE in the bridge-yard; and the information given on this branch of the subject will be found of great value to the practical bridge-builder.

"Students of Engineering will find this Text-Book INVALUABLE."—*Architect.*

"The author has certainly succeeded in producing a THOROUGHLY PRACTICAL Text-Book."—*Builder.*

"We can unhesitatingly recommend this work not only to the Student, as the BEST TEXT-BOOK on the subject, but also to the professional engineer as an EXCEEDINGLY VALUABLE book of reference."—*Mechanical World.*

"This work can be CONFIDENTLY recommended to engineers. The author has wisely chosen to use as little of the higher mathematics as possible, and has thus made his book of REAL USE TO THE PRACTICAL ENGINEER. . . . After careful perusal, we have nothing but praise for the work."—*Nature.*

In Large 8vo. Handsome Cloth. 10s. 6d.

CHEMISTRY FOR ENGINEERS.

BY

BERTRAM BLOUNT, F.I.C., F.C.S., A.I.C.E., Consulting Chemist to the Crown Agents for the Colonies.

AND

A. G. BLOXAM, F.I.C., F.C.S., Consulting Chemist, Head of the Chemistry Department, Goldsmiths' Inst., New Cross.

GENERAL CONTENTS.—Introduction—Chemistry of the Chief Materials of Construction—Sources of Energy—Chemistry of Steam-raising—Chemistry of Lubrication and Lubricants—Metallurgical Processes used in the Winning and Manufacture of Metals.

"The authors have SUCCEEDED beyond all expectation, and have produced a work which should give FRESH POWER to the Engineer and Manufacturer."—*The Times.*

"PRACTICAL THROUGHOUT . . . AN ADMIRABLE TEXT-BOOK, useful not only to Students, but to ENGINEERS and MANAGERS OF WORKS in PREVENTING WASTE and IMPROVING PROCESSES."—*Scotsman.*

"A book worthy to take HIGH RANK . . . treatment of the subject of GASEOUS FUEL particularly good. . . . WATER GAS and its production clearly worked out. . . . We WARMLY RECOMMEND the work."—*Journal of Gas Lighting.*

For Companion Volume by the same Authors, "CHEMISTRY FOR MANUFACTURERS," see p. 71.

WORKS BY WALTER R. BROWNE, M.A., M.INST.C.E.,

Late Fellow of Trinity College, Cambridge.

THE STUDENT'S MECHANICS:

An Introduction to the Study of Force and Motion.

With Diagrams. Crown 8vo. Cloth, 4s. 6d.

"Clear in style and practical in method, 'THE STUDENT'S MECHANICS' is cordially to be commended from all points of view."—*Athenæum.*

FOUNDATIONS OF MECHANICS.

Papers reprinted from the *Engineer.* In Crown 8vo, 1s.

Demy 8vo, with Numerous Illustrations, 9s.

FUEL AND WATER:

A Manual for Users of Steam and Water.

BY PROF. FRANZ SCHWACKHÖFER OF VIENNA, AND WALTER R. BROWNE, M.A., C.E.

GENERAL CONTENTS.—Heat and Combustion—Fuel, Varieties of—Firing Arrangements: Furnace, Flues, Chimney—The Boiler, Choice of—Varieties—Feed-water Heaters—Steam Pipes—Water: Composition, Purification—Prevention of Scale, &c., &c.

"The Section on Heat is one of the best and most lucid ever written."—*Engineer.*

"Cannot fail to be valuable to thousands using steam power."—*Railway Engineer.*

LONDON: CHARLES GRIFFIN & CO., LIMITED, EXETER STREET, STRAND.

SEWAGE DISPOSAL WORKS:

A Guide to the Construction of Works for the Prevention of the Pollution by Sewage of Rivers and Estuaries.

BY

W. SANTO CRIMP, M.INST.C.E., F.G.S.,

Late Assistant-Engineer, London County Council.

With Tables, Illustrations in the Text, and 37 Lithographic Plates. Medium 8vo. Handsome Cloth.

SECOND EDITION, REVISED AND ENLARGED. 30s.

PART I.—INTRODUCTORY.

Introduction.
Details of River Pollutions and Recommendations of Various Commissions.
Hourly and Daily Flow of Sewage.
The Pail System as Affecting Sewage.
The Separation of Rain-water from the Sewage Proper.
Settling Tanks.
Chemical Processes.
The Disposal of Sewage-sludge.
The Preparation of Land for Sewage Disposal.
Table of Sewage Farm Management.

PART II.—SEWAGE DISPOSAL WORKS IN OPERATION—THEIR CONSTRUCTION, MAINTENANCE, AND COST.

Illustrated by Plates showing the General Plan and Arrangement adopted in each District.

Map of the LONDON Sewage System.
Crossness Outfall.
Barking Outfall.
Doncaster Irrigation Farm.
Beddington Irrigation Farm, Borough of Croydon.
Bedford Sewage Farm Irrigation.
Dewsbury and Hitchin Intermittent Filtration.
Merton, Croydon Rural Sanitary Authority.
Swanwick, Derbyshire.
The Ealing Sewage Works.
Chiswick.
Kingston-on-Thames, A. B. C. Process.
Salford Sewage Works.
Bradford, Precipitation.
New Malden, Chemical Treatment and Small Filters.
Friern Barnet.
Acton, Ferozone and Polarite Process.
Ilford, Chadwell, and Dagenham Works
Coventry.
Wimbledon.
Birmingham.
Margate.
Portsmouth.
BERLIN Sewage Farms.
Sewage Precipitation Works, Dortmund (Germany).
Treatment of Sewage by Electrolysis.

*** From the fact of the Author's having, for some years, had charge of the Main Drainage Works of the Northern Section of the Metropolis, the chapter on LONDON will be found to contain many important details which would not otherwise have been available.

"All persons interested in Sanitary Science owe a debt of gratitude to Mr. Crimp. . . . His work will be especially useful to SANITARY AUTHORITIES and their advisers . . . EMINENTLY PRACTICAL AND USEFUL . . . gives plans and descriptions of MANY OF THE MOST IMPORTANT SEWAGE WORKS of England . . . with very valuable information as to the COST of construction and working of each. . . . The carefully-prepared drawings permit of an easy comparison between the different systems."—*Lancet.*

"Probably the MOST COMPLETE AND BEST TREATISE on the subject which has appeared in our language . Will prove of the greatest use to all who have the problem of Sewage Disposal to face."—*Edinburgh Medical Journal.*

Works by BRYAN DONKIN, M.Inst.C.E., M.Inst.Mech.E., &c.

GAS, OIL, AND AIR ENGINES:

A Practical Text-Book on Internal Combustion Motors without Boiler.

BY BRYAN DONKIN, M.INST.C.E., M.INST.MECH.E.

SECOND EDITION, Revised throughout and Enlarged. With numerous additional Illustrations. Large 8vo, Handsome Cloth. 25s.

GENERAL CONTENTS.—**Gas Engines**:—General Description—History and Development—British, French, and German Gas Engines—Gas Production for Motive Power—Theory of the Gas Engine—Chemical Composition of Gas in Gas Engines—Utilisation of Heat—Explosion and Combustion. **Oil Motors**:—History and Development—Various Types—Priestman's and other Oil Engines. **Hot-Air Engines**:—History and Development—Various Types: Stirling's, Ericsson's, &c., &c.

"The BEST BOOK NOW PUBLISHED on Gas, Oil, and Air Engines. . . . Will be of VERY GREAT INTEREST to the numerous practical engineers who have to make themselves familiar with the motor of the day. . . . Mr. Donkin has the advantage of LONG PRACTICAL EXPERIENCE, combined with HIGH SCIENTIFIC AND EXPERIMENTAL KNOWLEDGE, and an accurate perception of the requirements of Engineers."—*The Engineer.*

"We HEARTILY RECOMMEND Mr. Donkin's work. . . . A monument of careful labour. . . . Luminous and comprehensive."—*Journal of Gas Lighting.*

"A thoroughly RELIABLE and EXHAUSTIVE Treatise."—*Engineering.*

In Quarto, Handsome Cloth. With Numerous Plates. 25s.

STEAM BOILERS: LAND AND MARINE

(The Heat Efficiency of).

With many Tests and Experiments on different Types of Boilers, as to the Heating Value of Fuels, &c., with Analyses of Gases and Amount of Evaporation, and Suggestions for the Testing of Boilers.

BY BRYAN DONKIN, M.INST.C.E.

GENERAL CONTENTS.—Classification of different Types of Boilers—425 Experiments on English and Foreign Boilers with their Heat Efficiencies shown in Fifty Tables—Fire Grates of Various Types—Mechanical Stokers—Combustion of Fuel in Boilers—Transmission of Heat through Boiler Plates, and their Temperature—Feed Water Heaters, Superheaters, Feed Pumps, &c.—Smoke and its Prevention—Instruments used in Testing Boilers—Marine and Locomotive Boilers—Fuel Testing Stations—Discussion of the Trials and Conclusions—On the Choice of a Boiler, and Testing of Land, Marine, and Locomotive Boilers—Appendices—Bibliography—Index.

With Plates illustrating Progress made during the present Century, and the best Modern Practice.

"A WORK OF REFERENCE AT PRESENT UNIQUE. Will give an answer to almost any question connected with the performance of boilers that it is possible to ask."—*Engineer.*

"Probably the MOST EXHAUSTIVE *resumé* that has ever been collected. A PRACTICAL BOOK by a thoroughly practical man."—*Iron and Coal Trades Review.*

LONDON: CHARLES GRIFFIN & CO., LIMITED, EXETER STREET, STRAND.

SECOND EDITION, *Revised. Royal 8vo. With numerous Illustrations and 13 Lithographic Plates. Handsome Cloth. Price 30s.*

BRIDGE-CONSTRUCTION

(A PRACTICAL TREATISE ON):

Being a Text-Book on the Construction of Bridges in Iron and Steel.

FOR THE USE OF STUDENTS, DRAUGHTSMEN, AND ENGINEERS.

BY T. CLAXTON FIDLER, M. INST. C. E.,

Prof. of Engineering, University College, Dundee.

GENERAL CONTENTS.

PART I.—ELEMENTARY STATICS:—Definitions—The Opposition and Balance of Forces—Bending Strain—The Graphic Representation of Bending Moments.

PART II.—GENERAL PRINCIPLES OF BRIDGE-CONSTRUCTION:—The Comparative Anatomy of Bridges—Combined or Composite Bridges—Theoretical Weight of Bridges—On Deflection, or the Curve of a Bended Girder—Continuous Girders.

PART III.—THE STRENGTH OF MATERIALS:—Theoretical Strength of Columns—Design and Construction of Struts—Strength and Construction of Ties—Working Strength of Iron and Steel, and the Working Stress in Bridges—Wöhler's Experiments.

PART IV.—THE DESIGN OF BRIDGES IN DETAIL:—The Load on Bridges—Calculation of Stresses due to the Movable Load—Parallel Girders—Direct Calculation of the Weight of Metal—Parabolic Girders, Polygonal Trusses, and Curved Girders—Suspension Bridges and Arches: Flexible Construction—Rigid Construction—Bowstring Girders used as Arches or as Suspension Bridges—Rigid Arched Ribs or Suspension Ribs—Continuous Girders and Cantilever Bridges—The Niagara Bridge—The Forth Bridge—Wind-Pressure and Wind-Bracing: Modern Experiments.

"Mr. FIDLER'S SUCCESS arises from the combination of EXPERIENCE and SIMPLICITY OF TREATMENT displayed on every page. . . . Theory is kept in subordination to Practice, and his book is, therefore, as useful to girder-makers as to students of Bridge Construction."—*The Architect.*

"Of late years the American treatises on Practical and Applied Mechanics have taken the lead . . . since the opening up of a vast continent has given the American engineer a number of new bridge-problems to solve . . . but we look to the PRESENT TREATISE ON BRIDGE-CONSTRUCTION, and the Forth Bridge, to bring us to the front again."—*Engineer.*

"One of the VERY BEST RECENT WORKS on the Strength of Materials and its application to Bridge-Construction. . . Well repays a careful Study."—*Engineering.*

"An INDISPENSABLE HANDBOOK for the practical Engineer."—*Nature.*

FOURTH EDITION. Folio, strongly half-bound, 21/.

TRAVERSE TABLES:

Computed to Four Places of Decimals for every Minute of Angle up to 100 of Distance.

For the use of Surveyors and Engineers.

BY

RICHARD LLOYD GURDEN,

Authorised Surveyor for the Governments of New South Wales and Victoria.

*** *Published with the Concurrence of the Surveyors-General for New South Wales and Victoria.*

"Those who have experience in exact SURVEY-WORK will best know how to appreciate the enormous amount of labour represented by this valuable book. The computations enable the user to ascertain the sines and cosines for a distance of twelve miles to within half an inch, and this BY REFERENCE TO BUT ONE TABLE, in place of the usual Fifteen minute computations required. This alone is evidence of the assistance which the Tables ensure to every user, and as every Surveyor in active practice has felt the want of such assistance FEW KNOWING OF THEIR PUBLICATION WILL REMAIN WITHOUT THEM."
—*Engineer.*

In Large 8vo. With Numerous Illustrations. Price 7s. 6d.

VALVES AND VALVE-GEARING:

INCLUDING THE CORLISS VALVE AND TRIP GEARS.

BY

CHARLES HURST, Practical Draughtsman.

"CONCISE explanations illustrated by 115 VERY CLEAR DIAGRAMS and drawings and 4 folding-plates . . . the book fulfils a VALUABLE function."—*Athenæum.*

"MR. HURST'S VALVES and VALVE-GEARING will prove a very valuable aid, and tend to the production of Engines of SCIENTIFIC DESIGN and ECONOMICAL WORKING. . . . Will be largely sought after by Students and Designers."—*Marine Engineer.*

"USEFUL and THOROUGHLY PRACTICAL. Will undoubtedly be found of GREAT VALUE to all concerned with the design of Valve-gearing."—*Mechanical World.*

"Almost EVERY TYPE of VALVE and its gearing is clearly set forth, and illustrated in such a way as to be READILY UNDERSTOOD and PRACTICALLY APPLIED by either the Engineer, Draughtsman, or Student . . . Should prove both USEFUL and VALUABLE to all Engineers seeking for RELIABLE and CLEAR information on the subject. Its moderate price brings it within the reach of all"—*Industries and Iron.*

"Mr. HURST's work is ADMIRABLY suited to the needs of the practical mechanic. . . . It is free from any elaborate theoretical discussions, and the explanations of the various types of valve-gear are accompanied by diagrams which render them EASILY UNDERSTOOD."
—*The Scientific American.*

LONDON: CHARLES GRIFFIN & CO., LIMITED, EXETER STREET, STRAND.

WORKS BY
ANDREW JAMIESON, M.INST.C.E., M.I.E.E., F.R.S.E.,

Formerly Professor of Electrical Engineering, The Glasgow and West of Scotland Technical College.

PROFESSOR JAMIESON'S ADVANCED MANUALS.

In Large Crown 8vo. Fully Illustrated.

1. STEAM AND STEAM-ENGINES (A Text-Book on). For the Use of Students preparing for Competitive Examinations. With over 200 Illustrations, Folding Plates, and Examination Papers. TWELFTH EDITION. Revised and Enlarged, 8/6.

"Professor Jamieson fascinates the reader by his CLEARNESS OF CONCEPTION AND SIMPLICITY OF EXPRESSION. His treatment recalls the lecturing of Faraday."—*Athenæum.*

"The BEST BOOK yet published for the use of Students."—*Engineer.*

"Undoubtedly the MOST VALUABLE AND MOST COMPLETE Hand-book on the subject that now exists."—*Marine Engineer.*

2. MAGNETISM AND ELECTRICITY (An Advanced Text-Book on). Specially arranged for Advanced and "Honours" Students. By Prof. Jamieson, assisted by David Robertson, Jr., B.Sc.

3. APPLIED MECHANICS (An Advanced Text-Book on). Vol. I.—Comprising Part I.: The Principle of Work and its applications; Part II.: Gearing. Price 7s. 6d. THIRD EDITION.

"FULLY MAINTAINS the reputation of the Author—more we cannot say."—*Pract. Engineer.*

Vol. II.—Comprising Parts III. to VI.: Motion and Energy; Graphic Statics; Strength of Materials; Hydraulics and Hydraulic Machinery. SECOND EDITION. 8s. 6d.

"WELL AND LUCIDLY WRITTEN."—*The Engineer.*

PROFESSOR JAMIESON'S INTRODUCTORY MANUALS.

With numerous Illustrations and Examination Papers.

1. STEAM AND THE STEAM-ENGINE (Elementary Text-Book on). For First-Year Students. SIXTH EDITION. 3/6.

"Quite the RIGHT SORT OF BOOK."—*Engineer.*

"Should be in the hands of EVERY engineering apprentice."—*Practical Engineer.*

2. MAGNETISM AND ELECTRICITY (Elementary Text-Book on). For First-Year Students. FOURTH EDITION. 3/6.

"A CAPITAL TEXT-BOOK . . . The diagrams are an important feature."—*Schoolmaster.*

"A THOROUGHLY TRUSTWORTHY Text-book. . . . Arrangement as good as well can be. . . . Diagrams are also excellent. . . . The subject throughout treated as an essentially PRACTICAL one, and very clear instructions given."—*Nature.*

3. APPLIED MECHANICS (Elementary Text-Book on). Specially arranged for First-Year Students. THIRD EDITION, Revised and Enlarged. 3/6.

"Nothing is taken for granted. . . . The work has VERY HIGH QUALITIES, which may be condensed into the one word 'CLEAR.'"—*Science and Art.*

A POCKET-BOOK of ELECTRICAL RULES and TABLES.

FOR THE USE OF ELECTRICIANS AND ENGINEERS.

Pocket Size. Leather, 8s. 6d. *Thirteenth Edition.* *See p.* 43.

THIRD EDITION. *Very fully Illustrated. Cloth, 4s. 6d.*

STEAM - BOILERS:

THEIR DEFECTS, MANAGEMENT, AND CONSTRUCTION.

BY R. D. MUNRO,

Chief Engineer of the Scottish Boiler Insurance and Engine Inspection Company.

GENERAL CONTENTS.—I. EXPLOSIONS caused (1) by Overheating of Plates—(2) By Defective and Overloaded Safety Valves—(3) By Corrosion, Internal or External—(4) By Defective Design and Construction (Unsupported Flue Tubes; Unstrengthened Manholes; Defective Staying; Strength of Rivetted Joints; Factor of Safety)—II. CONSTRUCTION OF VERTICAL BOILERS: Shells—Crown Plates and Uptake Tubes—Man-Holes, Mud-Holes, and Fire-Holes—Fireboxes—Mountings—Management—Cleaning—Table of Bursting Pressures of Steel Boilers—Table of Rivetted Joints—Specifications and Drawings of Lancashire Boiler for Working Pressures (*a*) 80 lbs.; (*b*) 200 lbs. per square inch respectively.

This work contains information of the first importance to every user of Steam-power. It is a PRACTICAL work written for PRACTICAL men, the language and rules being throughout of the simplest nature.

"A valuable companion for workmen and engineers engaged about Steam Boilers, ought to be carefully studied, and ALWAYS AT HAND."—*Coll. Guardian.*

"The book is VERY USEFUL, especially to steam users, artisans, and young engineers."—*Engineer.*

BY THE SAME AUTHOR.

KITCHEN BOILER EXPLOSIONS: Why

they Occur, and How to Prevent their Occurrence. A Practical Handbook based on Actual Experiment. With Diagrams and Coloured Plate, Price 3s.

NYSTROM'S POCKET-BOOK OF MECHANICS

AND ENGINEERING. Revised and Corrected by W. DENNIS MARKS, Ph.B., C.E. (YALE S.S.S.), Whitney Professor of Dynamical Engineering, University of Pennsylvania. Pocket Size. Leather, 15s. TWENTY-FIRST EDITION, Revised and greatly enlarged.

LONDON: CHARLES GRIFFIN & CO., LIMITED, EXETER STREET, STRAND.

Large 8vo., Handsome Cloth. With numerous Plates reduced from Working Drawings and 280 Illustrations in the Text. 21s.

A MANUAL OF
LOCOMOTIVE ENGINEERING:

A Practical Text-Book for the Use of Engine Builders, Designers and Draughtsmen, Railway Engineers, and Students.

BY

WILLIAM FRANK PETTIGREW, M.INST.C.E.

With a Section on American and Continental Engines.

BY ALBERT F. RAVENSHEAR, B.SC.,

Of Her Majesty's Patent Office.

Contents.—Historical Introduction, 1763-1863.—Modern Locomotives: Simple.—Modern Locomotives: Compound. Primary Consideration in Locomotive Design.—Cylinders, Steam Chests, and Stuffing Boxes.—Pistons, Piston Rods, Crossheads, and Slide Bars.—Connecting and Coupling Rods.—Wheels and Axles, Axle Boxes, Hornblocks, and Bearing Springs.—Balancing.—Valve Gear.—Slide Valves and Valve Gear Details.—Framing, Bogies and Axle Trucks, Radial Axle Boxes.—Boilers.—Smokebox. Blast Pipe, Firebox Fittings.—Boiler Mountings.—Tenders.—Railway Brakes.—Lubrication.—Consumption of Fuel, Evaporation and Engine Efficiency.—American Locomotives.—Continental Locomotives.—Repairs, Running, Inspection, and Renewals.—Three Appendices.—Index.

"We recommend the book as THOROUGHLY PRACTICAL in its character, and MERITING A PLACE IN ANY COLLECTION of . . . works on Locomotive Engineering."—*Railway News.*

"The work CONTAINS ALL THAT CAN BE LEARNT from a book upon such a subject. It will at once rank as THE STANDARD WORK UPON THIS IMPORTANT SUBJECT."—*Railway Magazine.*

Large Crown 8vo. With numerous Illustrations. 6s.

ENGINE-ROOM PRACTICE:

A Handbook for Engineers and Officers in the Royal Navy and Mercantile Marine, Including the Management of the Main and Auxiliary Engines on Board Ship.

BY JOHN G. LIVERSIDGE,

Engineer, R.N., A.M.I.C.E., Instructor in Applied Mechanics at the Royal Naval College, Greenwich.

Contents.—General Description of Marine Machinery.—The Conditions of Service and Duties of Engineers of the Royal Navy.—Entry and Conditions of Service of Engineers of the Leading S.S. Companies.—Raising Steam.—Duties of a Steaming Watch on Engines and Boilers.—Shutting off Steam.—Harbour Duties and Watches.—Adjustments and Repairs of Engines.—Preservation and Repairs of "Tank" Boilers.—The Hull and its Fittings.—Cleaning and Painting Machinery.—Reciprocating Pumps, Feed Heaters, and Automatic Feed-Water Regulators.—Evaporators.—Steam Boats.—Electric Light Machinery.—Hydraulic Machinery.—Air-Compressing Pumps.—Refrigerating Machines.—Machinery of Destroyers.—The Management of Water-Tube Boilers.—Regulations for Entry of Assistant Engineers, R.N.—Questions given in Examinations for Promotion of Engineers, R.N.—Regulations respecting Board of Trade Examinations for Engineers, &c.

"The contents CANNOT FAIL TO BE APPRECIATED."—*The Steamship.*

"This VERY USEFUL BOOK. . . . ILLUSTRATIONS are of GREAT IMPORTANCE in a work of this kind, and it is satisfactory to find that SPECIAL ATTENTION has been given in this respect."—*Engineers' Gazette.*

WORKS BY

W. J. MACQUORN RANKINE, LL.D., F.R.S.,

Late Regius Professor of Civil Engineering in the University of Glasgow.

THOROUGHLY REVISED BY

W. J. MILLAR, C.E.,

Late Secretary to the Institute of Engineers and Shipbuilders in Scotland.

I. A MANUAL OF APPLIED MECHANICS:

Comprising the Principles of Statics and Cinematics, and Theory of Structures, Mechanism, and Machines. With Numerous Diagrams. Crown 8vo, cloth, 12s. 6d. FIFTEENTH EDITION.

II. A MANUAL OF CIVIL ENGINEERING:

Comprising Engineering Surveys, Earthwork, Foundations, Masonry, Carpentry, Metal Work, Roads, Railways, Canals, Rivers, Waterworks, Harbours, &c. With Numerous Tables and Illustrations. Crown 8vo, cloth, 16s. TWENTIETH EDITION.

III. A MANUAL OF MACHINERY AND MILLWORK:

Comprising the Geometry, Motions, Work, Strength, Construction, and Objects of Machines, &c. Illustrated with nearly 300 Woodcuts. Crown 8vo, cloth, 12s. 6d. SEVENTH EDITION.

IV. A MANUAL OF THE STEAM-ENGINE AND OTHER PRIME MOVERS:

With a Section on GAS, OIL, and AIR ENGINES. By BRYAN DONKIN, M.Inst.C.E. With Folding Plates and Numerous Illustrations. Crown 8vo, cloth, 12s. 6d. FOURTEENTH EDITION.

PROF. RANKINE'S WORKS—(*Continued*).

V. USEFUL RULES AND TABLES:

For Architects, Builders, Engineers, Founders, Mechanics, Shipbuilders, Surveyors, &c. With APPENDIX for the use of ELECTRICAL ENGINEERS. By Professor JAMIESON, F.R.S.E. SEVENTH EDITION. 10s. 6d.

VI. A MECHANICAL TEXT-BOOK:

A Practical and Simple Introduction to the Study of Mechanics. By Professor RANKINE and E. F. BAMBER, C.E. With Numerous Illustrations. Crown 8vo, cloth, 9s. FOURTH EDITION.

*** *The* "MECHANICAL TEXT-BOOK" *was designed by* Professor RANKINE *as an* INTRODUCTION *to the above Series of Manuals.*

VII. MISCELLANEOUS SCIENTIFIC PAPERS.

Royal 8vo. Cloth, 31s. 6d.

Part I. Papers relating to Temperature, Elasticity, and Expansion of Vapours, Liquids, and Solids. Part II. Papers on Energy and its Transformations. Part III. Papers on Wave-Forms, Propulsion of Vessels, &c.

With Memoir by Professor TAIT, M.A. Edited by W. J. MILLAR, C.E. With fine Portrait on Steel, Plates, and Diagrams.

"No more enduring Memorial of Professor Rankine could be devised than the publication of these papers in an accessible form. . . . The Collection is most valuable on account of the nature of his discoveries, and the beauty and completeness of his analysis. . . . The Volume exceeds in importance any work in the same department published in our time."—*Architect.*

SHELTON-BEY (W. Vincent, Foreman to the Imperial Ottoman Gun Factories, Constantinople):

THE MECHANIC'S GUIDE: A Hand-Book for Engineers and Artizans. With Copious Tables and Valuable Recipes for Practical Use. Illustrated. *Second Edition.* Crown 8vo. Cloth, 7/6.

SECOND EDITION, Revised and Enlarged.
In Large 8vo, Handsome cloth, 34s.

HYDRAULIC POWER

AND

HYDRAULIC MACHINERY.

BY

HENRY ROBINSON, M. INST. C.E., F.G.S.,

FELLOW OF KING'S COLLEGE, LONDON; PROF. OF CIVIL ENGINEERING, KING'S COLLEGE, ETC., ETC.

With numerous Woodcuts, and Sixty-nine Plates.

GENERAL CONTENTS.

Discharge through Orifices—Gauging Water by Weirs—Flow of Water through Pipes—The Accumulator—The Flow of Solids—Hydraulic Presses and Lifts—Cyclone Hydraulic Baling Press—Anderton Hydraulic Lift—Hydraulic Hoists (Lifts)—The Otis Elevator—Mersey Railway Lifts—City and South London Railway Lifts—North Hudson County Railway Elevator—Lifts for Subways—Hydraulic Ram—Pearsall's Hydraulic Engine—Pumping-Engines—Three-Cylinder Engines—Brotherhood Engine—Rigg's Hydraulic Engine—Hydraulic Capstans—Hydraulic Traversers—Movable Jigger Hoist—Hydraulic Waggon Drop—Hydraulic Jack—Duckham's Weighing Machine—Shop Tools—Tweddell's Hydraulic Rivetter—Hydraulic Joggling Press—Tweddell's Punching and Shearing Machine—Flanging Machine—Hydraulic Centre Crane—Wrightson's Balance Crane—Hydraulic Power at the Forth Bridge—Cranes—Hydraulic Coal-Discharging Machines—Hydraulic Drill—Hydraulic Manhole Cutter—Hydraulic Drill at St. Gothard Tunnel—Motors with Variable Power—Hydraulic Machinery on Board Ship—Hydraulic Points and Crossings—Hydraulic Pile Driver—Hydraulic Pile Screwing Apparatus—Hydraulic Excavator—Ball's Pump Dredger—Hydraulic Power applied to Bridges—Dock-gate Machinery—Hydraulic Brake—Hydraulic Power applied to Gunnery—Centrifugal Pumps—Water Wheels—Turbines—Jet Propulsion—The Gerard-Barré Hydraulic Railway—Greathead's Injector Hydrant—Snell's Hydraulic Transport System—Greathead's Shield—Grain Elevator at Frankfort—Packing—Power Co-operation—Hull Hydraulic Power Company—London Hydraulic Power Company—Birmingham Hydraulic Power System—Niagara Falls—Cost of Hydraulic Power—Meters—Schönheyder's Pressure Regulator—Deacon's Waste-Water Meter.

"A Book of great Professional Usefulness."—*Iron.*

*** The SECOND EDITION of the above important work has been thoroughly revised and brought up to date. Many new full-page Plates have been added—the number being increased from 43 in the First Edition to 69 in the present.

LONDON: CHARLES GRIFFIN & CO., LIMITED, EXETER STREET, STRAND.

Royal 8vo, Handsome Cloth, 25s.

THE STABILITY OF SHIPS.

BY

SIR EDWARD J. REED, K.C.B., F.R.S., M.P.,

KNIGHT OF THE IMPERIAL ORDERS OF ST. STANILAUS OF RUSSIA; FRANCIS JOSEPH OF AUSTRIA; MEDJIDIE OF TURKEY; AND RISING SUN OF JAPAN; VICE-PRESIDENT OF THE INSTITUTION OF NAVAL ARCHITECTS.

With numerous Illustrations and Tables.

THIS work has been written for the purpose of placing in the hands of Naval Constructors, Shipbuilders, Officers of the Royal and Mercantile Marines, and all Students of Naval Science, a complete Treatise upon the Stability of Ships, and is the only work in the English Language dealing exhaustively with the subject.

In order to render the work complete for the purposes of the Shipbuilder, whether at home or abroad, the Methods of Calculation introduced by Mr. F. K. BARNES, Mr. GRAY, M. RECH, M. DAYMARD, and Mr. BENJAMIN, are all given separately, illustrated by Tables and worked-out examples. The book contains more than 200 Diagrams, and is illustrated by a large number of actual cases, derived from ships of all descriptions, but especially from ships of the Mercantile Marine.

The work will thus be found to constitute the most comprehensive and exhaustive Treatise hitherto presented to the Profession on the Science of the STABILITY OF SHIPS.

"Sir EDWARD REED'S 'STABILITY OF SHIPS' is INVALUABLE. In it the STUDENT, new to the subject, will find the path prepared for him, and all difficulties explained with the utmost care and accuracy; the SHIP-DRAUGHTSMAN will find all the methods of calculation at present in use fully explained and illustrated, and accompanied by the Tables and Forms employed; the SHIPOWNER will find the variations in the Stability of Ships due to differences in forms and dimensions fully discussed, and the devices by which the state of his ships under all conditions may be graphically represented and easily understood; the NAVAL ARCHITECT will find brought together and ready to his hand, a mass of information which he would otherwise have to seek in an almost endless variety of publications, and some of which he would possibly not be able to obtain at all elsewhere."—*Steamship.*

"This IMPORTANT AND VALUABLE WORK . . . cannot be too highly recommended to all connected with shipping interests."—*Iron.*

"This VERY IMPORTANT TREATISE, . . . the MOST INTELLIGIBLE, INSTRUCTIVE, and COMPLETE that has ever appeared."—*Nature.*

"The volume is an ESSENTIAL ONE for the shipbuilding profession."—*Westminster Review.*

COMPANION-WORK.

THE DESIGN AND CONSTRUCTION OF SHIPS.

BY JOHN HARVARD BILES, M.Inst.N.A.,

Professor of Naval Architecture in the University of Glasgow.

In Preparation.

Fourteenth Edition, Revised. Price 21s.

Demy 8vo, Cloth. With Numerous Illustrations, reduced from Working Drawings.

A MANUAL OF MARINE ENGINEERING:

COMPRISING THE DESIGNING, CONSTRUCTION, AND WORKING OF MARINE MACHINERY.

By A. E. SEATON, M. Inst. C. E., M. Inst. Mech. E., M. Inst. N. A.

GENERAL CONTENTS.

Part I.—Principles of Marine Propulsion.

Part II.—Principles of Steam Engineering.

Part III.—Details of Marine Engines: Design and Calculations for Cylinders, Pistons, Valves, Expansion Valves, &c.

Part IV.—Propellers.

Part V.—Boilers.

Part VI.—Miscellaneous.

*** This EDITION includes a Chapter on WATER-TUBE BOILERS, with Illustrations of the leading Types and the Revised Rules of the *Bureau Veritas*.

"In the three-fold capacity of enabling a Student to learn how to design, construct, and work a Marine Steam-Engine, Mr. Seaton's Manual has NO RIVAL."—*Times.*

"The important subject of Marine Engineering is here treated with the THOROUGHNESS that it requires. No department has escaped attention. . . . Gives the results of much close study and practical work."—*Engineering.*

"By far the BEST MANUAL in existence. . . . Gives a complete account of the methods of solving, with the utmost possible economy, the problems before the Marine Engineer."—*Athenæum.*

"The Student, Draughtsman, and Engineer will find this work the MOST VALUABLE HANDBOOK of Reference on the Marine Engine now in existence."—*Marine Engineer.*

FIFTH EDITION, Thoroughly Revised. With two New Diagrams and Numerous Additions. Pocket-Size, Leather. 8s. 6d.

A POCKET-BOOK OF

MARINE ENGINEERING RULES AND TABLES,

FOR THE USE OF

Marine Engineers, Naval Architects, Designers, Draughtsmen, Superintendents and Others.

BY

A. E. SEATON, M.I.C.E., M.I.Mech.E., M.I.N.A.,

AND

H. M. ROUNTHWAITE, M.I.Mech.E., M.I.N.A.

"ADMIRABLY FULFILS its purpose."—*Marine Engineer.*

LONDON: CHARLES GRIFFIN & CO., LIMITED, EXETER STREET, STRAND.

WORKS BY PROF. ROBERT H. SMITH, Assoc.M.I.C.E.,

M.I.M.E., M.I.El.E., M.I.Min.E., Whit. Sch., M.Ord.Meiji.

THE CALCULUS FOR ENGINEERS AND PHYSICISTS,

Applied to Technical Problems.

WITH EXTENSIVE

CLASSIFIED REFERENCE LIST OF INTEGRALS.

By PROF. ROBERT H. SMITH.

ASSISTED BY

R. F. MUIRHEAD, M.A., B.Sc.,

Formerly Clark Fellow of Glasgow University, and Lecturer on Mathematics at Mason College.

In Crown 8vo, extra, with Diagrams and Folding-Plate. 8s. 6d.

"PROF. R. H. SMITH'S book will be serviceable in rendering a hard road AS EASY AS PRACTICABLE for the non-mathematical Student and Engineer."—*Athenæum.*

"Interesting diagrams, with practical illustrations of actual occurrence, are to be found here in abundance. THE VERY COMPLETE CLASSIFIED REFERENCE TABLE will prove very useful in saving the time of those who want an integral in a hurry."—*The Engineer.*

MEASUREMENT CONVERSIONS

(English and French):

28 GRAPHIC TABLES OR DIAGRAMS.

Showing at a glance the MUTUAL CONVERSION of MEASUREMENTS in DIFFERENT UNITS

Of Lengths, Areas, Volumes, Weights, Stresses, Densities, Quantities of Work, Horse Powers, Temperatures, &c.

For the use of Engineers, Surveyors, Architects, and Contractors.

In 4to, Boards. 7s. 6d.

*** Prof. SMITH'S CONVERSION-TABLES form the most unique and comprehensive collection ever placed before the profession. By their use much time and labour will be saved, and the chances of error in calculation diminished. It is believed that henceforth no Engineer's Office will be considered complete without them.

"The work is INVALUABLE."—*Colliery Guardian.*

"Ought to be in EVERY office where even occasional conversions are required. . . . Prof. SMITH'S TABLES form very EXCELLENT CHECKS on results."—*Electrical Review.*

"Prof. Smith deserves the hearty thanks, not only of the ENGINEER, but of the COMMERCIAL WORLD, for having smoothed the way for the ADOPTION of the METRIC SYSTEM of MEASUREMENT, a subject which is now assuming great importance as a factor in maintaining our HOLD upon FOREIGN TRADE."—*The Machinery Market.*

In Large 8vo. Handsome Cloth. With Plates and Illustrations. 16s.

LIGHT RAILWAYS

AT HOME AND ABROAD.

BY WILLIAM HENRY COLE, M.INST.C.E.,

Late Deputy-Manager, North-Western Railway, India.

Contents.—Discussion of the Term "Light Railways."—English Railways, Rates, and Farmers.—Light Railways in Belgium, France, Italy, other European Countries, America and the Colonies, India, Ireland.—Road Transport as an alternative.—The Light Railways Act, 1896.—The Question of Gauge.—Construction and Working.—Locomotives and Rolling-Stock.—Light Railways in England, Scotland, and Wales.—Appendices and Index.

"Mr. W. H. Cole has brought together . . . A LARGE AMOUNT of VALUABLE INFORMATION . . . hitherto practically inaccessible to the ordinary reader."—*Times.*

"THERE COULD BE NO BETTER BOOK of first reference on its subject. All classes of Engineers will welcome its appearance."—*Scotsman.*

THIRD EDITION, *Revised and Enlarged. Pocket-Size, Leather,* 12*s.* 6*d.; also Larger Size for Office Use, Cloth,* 12*s.* 6*d.*

Boilers, Marine and Land:

THEIR CONSTRUCTION AND STRENGTH.

A HANDBOOK OF RULES, FORMULÆ, TABLES, &C., RELATIVE TO MATERIAL, SCANTLINGS, AND PRESSURES, SAFETY VALVES, SPRINGS, FITTINGS AND MOUNTINGS, &C.

FOR THE USE OF ENGINEERS, SURVEYORS, BOILER-MAKERS, AND STEAM USERS.

BY T. W. TRAILL, M. INST. C. E., F. E. R. N.,

Late Engineer Surveyor-in-Chief to the Board of Trade.

*** TO THE SECOND AND THIRD EDITIONS MANY NEW TABLES for PRESSURES up to 200 LBS. per SQUARE INCH have been added.

"THE MOST VALUABLE WORK on Boilers published in England."—*Shipping World.*

"Contains an ENORMOUS QUANTITY OF INFORMATION arranged in a very convenient form. . . A MOST USEFUL VOLUME . . . supplying information to be had nowhere else."—*The Engineer.*

LONDON: CHARLES GRIFFIN & CO., LIMITED, EXETER STREET, STRAND.

In Crown 8vo, extra, with Numerous Illustrations. [*Shortly.*

GAS AND OIL ENGINES:

AN INTRODUCTORY TEXT-BOOK

On the Theory, Design, Construction, and Testing of Internal Combustion Engines without Boiler.

FOR THE USE OF STUDENTS.

BY

PROF. W. H. WATKINSON, WHIT. SCH., M.INST.MECH.E.,
Glasgow and West of Scotland Technical College.

Engineering Drawing and Design

(A TEXT-BOOK OF).

SECOND EDITION. In Two Parts, Published Separately.

VOL. I.—PRACTICAL GEOMETRY, PLANE, AND SOLID. 3s.
VOL. II.—MACHINE AND ENGINE DRAWING AND DESIGN. 4s. 6d.

BY

SIDNEY H. WELLS, WH.SC.,
A.M.INST.C.E., A.M.INST.MECH.E.,
Principal of the Battersea Polytechnic Institute, and Head of the Engineering Department therein; formerly of the Engineering Departments of the Yorkshire College, Leeds; and Dulwich College, London.

With many Illustrations, specially prepared for the Work, and numerous Examples, for the Use of Students in Technical Schools and Colleges.

"A THOROUGHLY USEFUL WORK, exceedingly well written. For the many Examples and Questions we have nothing but praise."—*Nature.*

"A CAPITAL TEXT-BOOK, arranged on an EXCELLENT SYSTEM, calculated to give an intelligent grasp of the subject, and not the mere faculty of mechanical copying. . . . Mr. Wells shows how to make COMPLETE WORKING-DRAWINGS, discussing fully each step in the design."—*Electrical Review.*

"The first book leads EASILY and NATURALLY towards the second, where the technical pupil is brought into contact with large and more complex designs."—*The Schoolmaster.*

MUNRO & JAMIESON'S ELECTRICAL POCKET-BOOK.

THIRTEENTH EDITION, Revised and Enlarged.

A POCKET-BOOK

OF

ELECTRICAL RULES & TABLES

FOR THE USE OF ELECTRICIANS AND ENGINEERS.

BY JOHN MUNRO, C.E., & PROF. JAMIESON, M.INST.C.E., F.R.S.E.

With Numerous Diagrams. Pocket Size. Leather, 8s. 6d.

GENERAL CONTENTS.

UNITS OF MEASUREMENT.
MEASURES.
TESTING.
CONDUCTORS.
DIELECTRICS.
SUBMARINE CABLES.
TELEGRAPHY.
ELECTRO-CHEMISTRY.
ELECTRO-METALLURGY.
BATTERIES.
DYNAMOS AND MOTORS.
TRANSFORMERS.
ELECTRIC LIGHTING.
MISCELLANEOUS.
LOGARITHMS.
APPENDICES.

"WONDERFULLY PERFECT. . . . Worthy of the highest commendation we can give it."—*Electrician.*

"The STERLING VALUE of Messrs. MUNRO and JAMIESON'S POCKET-BOOK."—*Electrical Review.*

Electrical Measurements & Instruments.

A Practical Hand-book of Testing for the Electrical Engineer.

BY CHARLES H. YEAMAN,

Assoc. Inst. E.E., formerly Electrical Engineer to the Corporation of Liverpool.

[*In Preparation.*

SECOND EDITION, 8s. 6d. Leather, for the Pocket, 8s. 6d.

GRIFFIN'S ELECTRICAL PRICE-BOOK.

For Electrical, Civil, Marine, and Borough Engineers, Local Authorities, Architects, Railway Contractors, &c., &c.

EDITED BY H. J. DOWSING,

Member of the Institution of Electrical Engineers; of the Society of Arts; of the London Chamber of Commerce, &c.

"The ELECTRICAL PRICE-BOOK REMOVES ALL MYSTERY about the cost of Electrical Power. By its aid the EXPENSE that will be entailed by utilising electricity on a large or small scale can be discovered."—*Architect.*

"The value of this Electrical Price-Book CANNOT BE OVER-ESTIMATED. . . . Will save time and trouble both to the engineer and the business man."—*Machinery.*

LONDON: CHARLES GRIFFIN & CO., LIMITED, EXETER STREET, STRAND.

By PROFESSORS J. H. POYNTING & J. J. THOMSON.

In Large 8vo. Fully Illustrated.

A TEXT-BOOK OF PHYSICS:

COMPRISING

PROPERTIES OF MATTER; SOUND; HEAT; MAGNETISM AND ELECTRICITY; AND LIGHT.

BY

J. H. POYNTING,
SC.D., F.R.S.,
Late Fellow of Trinity College, Cambridge; Professor of Physics, Mason College, Birmingham.

AND

J. J. THOMSON,
M.A., F.R.S.,
Fellow of Trinity College, Cambridge; Prof. of Experimental Physics in the University of Cambridge.

Volume I., Now Ready, Price 8s. 6d.

SOUND.

Contents.—The Nature of Sound and its chief Characteristics.—The Velocity of Sound in Air and other Media.—Reflection and Refraction of Sound.—Frequency and Pitch of Notes.—Resonance and Forced Oscillations.—Analysis of Vibrations.—The Transverse Vibrations of Stretched Strings or Wires.—Pipes and other Air Cavities.—Rods.—Plates.—Membranes.—Vibrations maintained by Heat.—Sensitive Flames and Jets.—Musical Sand.—The Superposition of Waves.—Index.

*** *Publishers' Note.*—It is intended that this IMPORTANT and LONG-EXPECTED TREATISE shall be issued in separate Volumes, each complete in itself, and published at regular intervals.

In large 8vo, with Bibliography, Illustrations in the Text, and seven Lithographed Plates. 12s. 6d.

THE MEAN DENSITY OF THE EARTH:

An Essay to which the Adams Prize was adjudged in 1893 in the University of Cambridge.

BY

J. H. POYNTING, Sc.D., F.R.S.,

Late Fellow of Trinity College, Cambridge; Professor of Physics, Mason College, Birmingham.

"An account of this subject cannot fail to be of GREAT and GENERAL INTEREST to the scientific mind. Especially is this the case when the account is given by one who has contributed so considerably as has Prof. Poynting to our present state of knowledge with respect to a very difficult subject. . . . Remarkably has Newton's estimate been verified by Prof. Poynting."—*Athenæum.*

LONDON: CHARLES GRIFFIN & CO., LIMITED, EXETER STREET, STRAND.

§6. GRIFFIN'S NAUTICAL SERIES.

EDITED BY EDW. BLACKMORE,
Master Mariner, First Class Trinity House Certificate, Assoc. Inst. N.A.;
AND WRITTEN, MAINLY, by SAILORS for SAILORS.

"This ADMIRABLE SERIES."—*Fairplay.* "A VERY USEFUL SERIES."—*Nature.*
"The volumes of MESSRS. GRIFFIN'S NAUTICAL SERIES may well and profitably be read by ALL interested in our NATIONAL MARITIME PROGRESS."—*Marine Engineer.*
"EVERY SHIP should have the WHOLE SERIES as a REFERENCE LIBRARY. HANDSOMELY BOUND, CLEARLY PRINTED and ILLUSTRATED."—*Liverpool Journ. of Commerce.*

The British Mercantile Marine: An Historical Sketch of its Rise and Development. By the EDITOR, CAPT. BLACKMORE. 3s. 6d.
"Captain Blackmore's SPLENDID BOOK . . . contains paragraphs on every point of interest to the Merchant Marine. The 243 pages of this book are THE MOST VALUABLE to the sea captain that have EVER been COMPILED."—*Merchant Service Review.*

Elementary Seamanship. By D. WILSON-BARKER, Master Mariner, F.R.S.E., F.R.G.S. With numerous Plates, two in Colours, and Frontispiece. SECOND EDITION, Revised. 5s.
"This ADMIRABLE MANUAL, by CAPT. WILSON BARKER, of the 'Worcester,' seems to us PERFECTLY DESIGNED."—*Athenæum.*

Know Your Own Ship: A Simple Explanation of the Stability, Construction, Tonnage, and Freeboard of Ships. By THOS. WALTON, Naval Architect. With numerous Illustrations and additional Chapters on Buoyancy, Trim, and Calculations. FOURTH EDITION, Revised. 7s. 6d.
"MR. WALTON'S book will be found VERY USEFUL."—*The Engineer.*

The Construction and Maintenance of Vessels built of Steel. By THOS. WALTON, Naval Architect. [*Shortly.*

Navigation: Theoretical and Practical. By D. WILSON-BARKER, Master Mariner, &c., and WILLIAM ALLINGHAM. 3s. 6d.
"PRECISELY the kind of work required for the New Certificates of competency. Candidates will find it INVALUABLE."—*Dundee Advertiser.*

Latitude and Longitude: How to find them. By W. J. MILLAR, C.E., late Sec. to the Inst. of Engineers and Shipbuilders in Scotland. 2s.
"Cannot but prove an acquisition to those studying Navigation."—*Marine Engineer.*

Practical Mechanics: Applied to the requirements of the Sailor. By THOS. MACKENZIE, Master Mariner, F.R.A.S. 3s. 6d.
"WELL WORTH the money . . . EXCEEDINGLY HELPFUL."—*Shipping World.*

Marine Meteorology: For Officers of the Merchant Navy. By WILLIAM ALLINGHAM, First Class Honours, Navigation, Science and Art Department. [*Shortly.*

Trigonometry: For the Young Sailor, &c. By RICH. C. BUCK, of the Thames Nautical Training College, H.M.S. "Worcester." Price 3s. 6d.
"This EMINENTLY PRACTICAL and RELIABLE volume."—*Schoolmaster.*

Practical Algebra. By RICH. C. BUCK. Companion Volume to the above, for Sailors and others. Price 3s. 6d.
"It is just the book for the young sailor mindful of progress."—*Nautical Magazine.*

The Legal Duties of Shipmasters. By BENEDICT WM. GINSBURG, M.A., LL.D., of the Inner Temple and Northern Circuit; Barrister-at-Law. Price 4s. 6d.
"INVALUABLE to Masters. . . . We can fully recommend it."—*Shipping Gazette.*

A Medical and Surgical Help for Shipmasters. Including First Aid at Sea. By WM. JOHNSON SMITH, F.R.C.S., Principal Medical Officer, Seaman's Hospital, Greenwich. 6s.
"SOUND, JUDICIOUS, REALLY HELPFUL."—*The Lancet.*

GRIFFIN'S NAUTICAL SERIES.

Price 3s. 6d. Post-free.

THE

British Mercantile Marine.

BY EDWARD BLACKMORE,

MASTER MARINER; ASSOCIATE OF THE INSTITUTION OF NAVAL ARCHITECTS; MEMBER OF THE INSTITUTION OF ENGINEERS AND SHIPBUILDERS IN SCOTLAND; EDITOR OF GRIFFIN'S "NAUTICAL SERIES."

GENERAL CONTENTS.—HISTORICAL: From Early Times to 1486—Progress under Henry VIII.—To Death of Mary—During Elizabeth's Reign—Up to the Reign of William III.—The 18th and 19th Centuries—Institution of Examinations—Rise and Progress of Steam Propulsion—Development of Free Trade—Shipping Legislation, 1862 to 1875—"Locksley Hall" Case—Shipmasters' Societies—Loading of Ships—Shipping Legislation, 1884 to 1894—Statistics of Shipping. THE PERSONNEL: Shipowners—Officers—Mariners—Duties and Present Position. EDUCATION: A Seaman's Education: what it should be—Present Means of Education—Hints. DISCIPLINE AND DUTY—Postscript—The Serious Decrease in the Number of British Seamen, a Matter demanding the Attention of the Nation.

"INTERESTING and INSTRUCTIVE . . . may be read WITH PROFIT and ENJOYMENT."—*Glasgow Herald.*

"EVERY BRANCH of the subject is dealt with in a way which shows that the writer 'knows the ropes' familiarly."—*Scotsman.*

"This ADMIRABLE book . . . TERMS with useful information—Should be in the hands of every Sailor."—*Western Morning News.*

WORKS BY RICHARD C. BUCK,

of the Thames Nautical Training College, H.M.S. 'Worcester.'

1. A Manual of Trigonometry:

With Diagrams, Examples, and Exercises. Post-free 3s. 6d.

*** Mr. Buck's Text-Book has been SPECIALLY PREPARED with a view to the New Examinations of the Board of Trade, in which Trigonometry is an obligatory subject.

"This EMINENTLY PRACTICAL and RELIABLE VOLUME."—*Schoolmaster.*

2. A Manual of Algebra.

Designed to meet the Requirements of Sailors and others. Price 3s. 6d.

*** These elementary works on ALGEBRA and TRIGONOMETRY are written specially for those who will have little opportunity of consulting a Teacher. They are books for "SELF-HELP." All but the simplest explanations have, therefore, been avoided, and ANSWERS to the Exercises are given. Any person may readily, by careful study, become master of their contents, and thus lay the foundation for a further mathematical course, if desired. It is hoped that to the younger Officers of our Mercantile Marine they will be found decidedly serviceable. The Examples and Exercises are taken from the Examination Papers set for the Cadets of the "Worcester."

*** For complete List of GRIFFIN'S NAUTICAL SERIES, see p. 45.

GRIFFIN'S NAUTICAL SERIES.

SECOND EDITION. *Price 5s. Post-free.*

A MANUAL OF

ELEMENTARY SEAMANSHIP.

BY

D. WILSON-BARKER, MASTER MARINER; F.R.S.E., F.R.G.S., &c., &c.;
YOUNGER BROTHER OF THE TRINITY HOUSE.

With Frontispiece, Twelve Plates (Two in Colours), and Illustrations in the Text.

GENERAL CONTENTS.—The Building of a Ship; Parts of Hull. Masts, &c.—Ropes, Knots, Splicing, &c. — Gear, Lead and Log, &c. — Rigging, Anchors — Sailmaking — The Sails, &c — Handling of Boats under Sail — Signals and Signalling—Rule of the Road—Keeping and Relieving Watch—Points of Etiquette—Glossary of Sea Terms and Phrases—Index.

*** The volume contains the NEW RULES OF THE ROAD.

"This ADMIRABLE MANUAL, by CAPT. WILSON-BARKER of the "Worcester," seems to us PERFECTLY DESIGNED, and holds its place excellently in 'GRIFFIN'S NAUTICAL SERIES.' . . . Although intended for those who are to become Officers of the Merchant Navy, it will be found useful by ALL YACHTSMEN."—*Athenæum.*

"Five shillings will be WELL SPENT on this little book. CAPT. WILSON-BARKER knows from experience what a young man wants at the outset of his career."—*The Engineer.*

Price 3s. 6d. Post-free.

NAVIGATION:

PRACTICAL AND THEORETICAL.

BY DAVID WILSON-BARKER, R.N.R., F.R.S.E., &c., &c.,

AND

WILLIAM ALLINGHAM,

FIRST-CLASS HONOURS, NAVIGATION, SCIENCE AND ART DEPARTMENT.

With Numerous Illustrations and Examination Questions.

GENERAL CONTENTS.—Definitions—Latitude and Longitude—Instruments of Navigation—Correction of Courses—Plane Sailing—Traverse Sailing—Day's Work — Parallel Sailing — Middle Latitude Sailing — Mercator's Chart—Mercator Sailing—Current Sailing—Position by Bearings—Great Circle Sailing —The Tides—Questions—Appendix: Compass Error—Numerous Useful Hints, &c —Index.

"PRECISELY the kind of work required for the New Certificates of competency in grades from Second Mate to extra Master. . . . Candidates will find it INVALUABLE."—*Dundee Advertiser.*

"A CAPITAL LITTLE BOOK . . . specially adapted to the New Examinations. The Authors are CAPT. WILSON-BARKER (Captain-Superintendent of the Nautical College, H.M.S. "Worcester," who has had great experience in the highest problems of Navigation), and MR. ALLINGHAM, a well-known writer on the Science of Navigation and Nautical Astronomy."—*Shipping World.*

*** For complete List of GRIFFIN'S NAUTICAL SERIES, see p. 45.

GRIFFIN'S NAUTICAL SERIES.

Crown 8vo, with Numerous Illustrations. Handsome Cloth. 3s. 6d.

Practical Mechanics:

Applied to the Requirements of the Sailor.

BY THOS. MACKENZIE,

Master Mariner, F.R.A.S.

GENERAL CONTENTS.—Resolution and Composition of Forces—Work done by Machines and Living Agents—The Mechanical Powers: The Lever; Derricks as Bent Levers—The Wheel and Axle: Windlass; Ship's Capstan; Crab Winch—Tackles: the "Old Man"—The Inclined Plane; the Screw—The Centre of Gravity of a Ship and Cargo—Relative Strength of Rope: Steel Wire, Manilla, Hemp, Coir—Derricks and Shears—Calculation of the Cross-breaking Strain of Fir Spar—Centre of Effort of Sails—Hydrostatics: the Diving-bell; Stability of Floating Bodies; the Ship's Pump, &c.

"THIS EXCELLENT BOOK . . . contains a LARGE AMOUNT of information." —*Nature.*

"WELL WORTH the money . . . will be found EXCEEDINGLY HELPFUL."—*Shipping World.*

"NO SHIPS' OFFICERS' BOOKCASE will henceforth be complete without CAPTAIN MACKENZIE'S 'PRACTICAL MECHANICS.' Notwithstanding my many years' experience at sea, it has told me *how much more there is to acquire.*"—(Letter to the Publishers from a Master Mariner).

"I must express my thanks to you for the labour and care you have taken in 'PRACTICAL MECHANICS.' . . . IT IS A LIFE'S EXPERIENCE. . . . What an amount we frequently see wasted by rigging purchases without reason and accidents to spars, &c., &c.! 'PRACTICAL MECHANICS' WOULD SAVE ALL THIS."—(Letter to the Author from another Master Mariner).

Crown 8vo, with Diagrams. 2s. Post-free.

Latitude and Longitude:

How to Find them.

BY W. J. MILLAR, C.E.,

Late Secretary to the Inst. of Engineers and Shipbuilders in Scotland.

"CONCISELY and CLEARLY WRITTEN . . . cannot but prove an acquisition to those studying Navigation."—*Marine Engineer.*

"Young Seamen will find it HANDY and USEFUL, SIMPLE and CLEAR."—*The Engineer.*

*** For Complete List of GRIFFIN'S NAUTICAL SERIES, see p. 45.

GRIFFIN'S NAUTICAL SERIES.

In Crown 8vo. Handsome Cloth. 4s. 6d. Post-free.

THE LEGAL DUTIES OF SHIPMASTERS.

BY

BENEDICT WM. GINSBURG, M.A., LL.D. (CANTAB.),
Of the Inner Temple and Northern Circuit; Barrister-at-Law.

General Contents.—The Qualification for the Position of Shipmaster—The Contract with the Shipowner—The Master's Duty in respect of the Crew: Engagement; Apprentices; Discipline; Provisions, Accommodation, and Medical Comforts; Payment of Wages and Discharge—The Master's Duty in respect of the Passengers—The Master's Financial Responsibilities—The Master's Duty in respect of the Cargo—The Master's Duty in Case of Casualty—The Master's Duty to certain Public Authorities—The Master's Duty in relation to Pilots, Signals, Flags, and Light Dues—The Master's Duty upon Arrival at the Port of Discharge—Appendices relative to certain Legal Matters: Board of Trade Certificates, Dietary Scales, Stowage of Grain Cargoes, Load Line Regulations, Life-saving Appliances, Carriage of Cattle at Sea, &c., &c.—Copious Index.

"No intelligent Master should fail to add this to his list of useful and necessary books. The price (4s. 6d.) cannot be quoted as an excuse for non-possession, and a few lines of it may SAVE A LAWYER'S FEE, BESIDES ENDLESS WORRY."—*Liverpool Journal of Commerce.*

"SENSIBLE, plainly written, in CLEAR and NON-TECHNICAL LANGUAGE, and will be found of MUCH SERVICE by the Shipmaster."—*British Trade Review.*

FIRST AID AT SEA.

With Coloured Plates and Numerous Illustrations. 6s.

A MEDICAL AND SURGICAL HELP

FOR SHIPMASTERS AND OFFICERS *IN THE MERCHANT NAVY.*

BY

WM. JOHNSON SMITH, F.R.C.S.,
Principal Medical Officer, Seamen's Hospital, Greenwich.

*** The attention of all interested in our Merchant Navy is requested to this exceedingly useful and valuable work. It is needless to say that it is the outcome of many years PRACTICAL EXPERIENCE amongst Seamen.

"SOUND, JUDICIOUS, REALLY HELPFUL."—*The Lancet.*

MARINE METEOROLOGY

FOR OFFICERS OF THE MERCHANT NAVY.

BY

WILLIAM ALLINGHAM,
Joint-Author of "Navigation, Theoretical and Practical."

[*In Preparation.*

*** For Complete List of GRIFFIN'S NAUTICAL SERIES, see p. 45.

GRIFFIN'S NAUTICAL SERIES.

FOURTH EDITION. *Revised throughout, with additional Chapters on Trim, Buoyancy, and Calculations. Numerous Illustrations. Handsome Cloth, Crown 8vo. 7s. 6d.*

KNOW YOUR OWN SHIP.

BY THOMAS WALTON, NAVAL ARCHITECT.

SPECIALLY ARRANGED TO SUIT THE REQUIREMENTS OF SHIPS' OFFICERS, SHIPOWNERS, SUPERINTENDENTS, DRAUGHTSMEN, ENGINEERS, AND OTHERS.

This work explains, in a simple manner, such important subjects as:—

Displacement, Deadweight, Tonnage, Freeboard, Moments, Buoyancy, Strain, Structure, Stability, Rolling, Ballasting, Loading, Shifting Cargoes, Admission of Water, Sail Area, &c., &c.

"The little book will be found EXCEEDINGLY HANDY by most officers and officials connected with shipping. . . . Mr. Walton's work will obtain LASTING SUCCESS, because of its unique fitness for those for whom it has been written."—*Shipping World.*

"An EXCELLENT WORK, full of solid instruction and INVALUABLE to every officer of the Mercantile Marine who has his profession at heart."—*Shipping.*

"Not one of the 242 pages could well be spared. It will admirably fulfil its purpose . . . useful to ship owners, ship superintendents, ship draughtsmen, and all interested in shipping."—*Liverpool Journal of Commerce.*

"A mass of VERY USEFUL INFORMATION, accompanied by diagrams and illustrations, is given in a compact form."—*Fairplay*

"A large amount of MOST USEFUL INFORMATION is given in the volume. The book is certain to be of great service to those who desire to be thoroughly grounded in the subject of which it treats."—*Steamship.*

"We have found no one statement that we could have wished differently expressed. The matter has, so far as clearness allows, been admirably condensed, and is simple enough to be understood by every seaman."—*Marine Engineer.*

BY THE SAME AUTHOR.

In Preparation.

THE CONSTRUCTION AND MAINTENANCE OF VESSELS BUILT OF STEEL.

Illustrated with Numerous Plates and Diagrams.

*** For Complete List of GRIFFIN'S NAUTICAL SERIES, see p. 45.

§§ 7-8. Griffin's Geological, Prospecting, Mining, and Metallurgical Publications.

		PAGE
Geology, Stratigraphical,	R. ETHERIDGE, F.R.S.,	52
„ **Physical,**	PROF. H. G. SEELEY,	52
„ **Practical Aids,** 3rd Ed.,	PROF. GRENVILLE COLE,	53
„ **Open Air Studies,**	„ „	86
Griffin's "New Land" Series for Prospectors,	Ed. by PROF. COLE,	54
1. Prospecting for Minerals,	S. HERBERT COX, A.R.S.M.,	55
2. Food Supply,	ROBT. BRUCE,	54
3. New Lands and their Prospective Advantages,	H. R. MILL, D.Sc., F.R.S.E.	54
4. Building Construction,	PROF. JAS. LYON,	54
Ore and Stone Mining, 2nd Ed.,	PROF. LE NEVE FOSTER,	56
Elementary Mining,	„ „	56
Coal Mining, 3rd Ed.,	H. W. HUGHES, F.G.S,	57
Petroleum,	REDWOOD AND HOLLOWAY,	58
Mine-Surveying, 6th Ed.,	BENNETT H. BROUGH, A.R.S.M.,	59
Blasting and Explosives,	O. GUTTMANN, A.M.I.C.E.,	59
Mine Accounts,	PROF. J. G. LAWN,	60
Metallurgy (General Treatise on), 3rd Ed.,	PHILLIPS AND BAUERMAN,	61
„ **(Elementary),**	PROF. HUMBOLDT SEXTON,	66
Assaying, 5th Ed.,	J. J. & C. BERINGER,	66
Griffin's Metallurgical Series	Ed. by PROF. ROBERTS-AUSTEN, C.B., F.R.S.,	62
1. Introduction to Metallurgy, 4th Ed.,	PROF. ROBERTS-AUSTEN,	63
2. Gold, Metallurgy of, 3rd Ed.,	DR. KIRKE ROSE, A.R.S.M.,	64
3. Iron, Metallurgy of,	THOS. TURNER, A.R.S.M.,	65
4. Steel, „	F. W. HARBORD, A.R.S.M.,	65
5. Silver and Lead, „	H. F. COLLINS, A.R.S.M.,	65
6. Metallurgical Machinery,	H. C. JENKINS, A.R.S.M.,	62
Getting Gold, 2nd Ed.,	J. C. F. JOHNSON, F.G.S.,	55
Electric Smelting and Refining,	BORCHERS AND MCMILLAN,	67
Tables for Quantitative Metallurgical Analysis,	J. JAMES MORGAN,	67
Electro-Metallurgy,	W. G. MCMILLAN, F.I.C.,	68
Goldsmith and Jeweller's Art,	THOS. B. WIGLEY,	68

Demy 8vo, Handsome cloth, 18s.

Physical Geology and Palæontology,

ON THE BASIS OF PHILLIPS.

BY

HARRY GOVIER SEELEY, F.R.S.,

PROFESSOR OF GEOGRAPHY IN KING'S COLLEGE, LONDON.

With Frontispiece in Chromo-Lithography, and Illustrations.

"It is impossible to praise too highly the research which PROFESSOR SEELEY'S 'PHYSICAL GEOLOGY' evidences. IT IS FAR MORE THAN A TEXT-BOOK—it is a DIRECTORY to the Student in prosecuting his researches."—*Presidential Address to the Geological Society*, 1885, *by Rev. Prof. Bonney D.Sc., LL.D., F.R.S.*

"PROFESSOR SEELEY maintains in his 'PHYSICAL GEOLOGY' the high reputation he already deservedly bears as a Teacher."—*Dr. Henry Woodward, F.R.S., in the "Geological Magazine."*

"PROFESSOR SEELEY'S work includes one of the most satisfactory Treatises on Lithology in the English language. . . . So much that is not accessible in other works is presented in this volume, that no Student of Geology can afford to be without it."—*American Journal of Engineering.*

Demy 8vo, Handsome cloth, 34s.

Stratigraphical Geology & Palæontology,

ON THE BASIS OF PHILLIPS.

BY

ROBERT ETHERIDGE, F.R.S.,

OF THE NATURAL HIST. DEPARTMENT, BRITISH MUSEUM, LATE PALÆONTOLOGIST TO THE GEOLOGICAL SURVEY OF GREAT BRITAIN, PAST PRESIDENT OF THE GEOLOGICAL SOCIETY, ETC.

With Map, Numerous Tables, and Thirty-six Plates.

"No such compendium of geological knowledge has ever been brought together before."—*Westminster Review.*

"If PROF. SEELEY'S volume was remarkable for its originality and the breadth of its views, Mr. ETHERIDGE fully justifies the assertion made in his preface that his book differs in construction and detail from any known manual . . . Must take HIGH RANK AMONG WORKS OF REFERENCE."—*Athenæum.*

Works by GRENVILLE A. J. COLE, M.R.I.A., F.G.S.,
Professor of Geology in the Royal College of Science for Ireland.

PRACTICAL GEOLOGY
(AIDS IN):

WITH A SECTION ON PALÆONTOLOGY.

BY PROFESSOR GRENVILLE COLE, M.R.I.A., F.G.S.

THIRD EDITION, Revised and in part Re-written. With Frontispiece and Illustrations. Cloth, 10s. 6d.

GENERAL CONTENTS.—

PART I.—SAMPLING OF THE EARTH'S CRUST.
PART II.—EXAMINATION OF MINERALS.
PART III.—EXAMINATION OF ROCKS.
PART IV.—EXAMINATION OF FOSSILS.

"Prof. Cole treats of the examination of minerals and rocks in a way that has never been attempted before . . . DESERVING OF THE HIGHEST PRAISE. Here indeed are 'Aids' INNUMERABLE and INVALUABLE. All the directions are given with the utmost clearness and precision."—*Athenæum.*

"To the younger workers in Geology, Prof. Cole's book wil be as INDISPENSABLE as a dictionary to the learners of a language."—*Saturday Review.*

"That the work deserves its title, that it is full of 'AIDS,' and in the highest degree 'PRACTICAL,' will be the verdict of all who use it."—*Nature.*

"This EXCELLENT MANUAL . . . will be A VERY GREAT HELP. . . . The section on the EXAMINATION OF FOSSILS is probably the BEST of its kind yet published. . . . FULL of well-digested information from the newest sources and from personal research."—*Annals of Nat. History.*

OPEN-AIR STUDIES:
An Introduction to Geology Out-of-doors.

BY PROFESSOR GRENVILLE COLE, M.R.I.A., F.G.S.

With 12 Full-Page Illustrations from Photographs.
Cloth. 8*s.* 6*d.*

For details, see p. 86.

Edited by PROFESSOR COLE.

The "New Land" Series for Colonists and Prospectors

(See next page).

The "New Land" Series

OF

Practical Hand-Books

For the Use of Prospectors, Explorers, Settlers, Colonists, and all Interested in the opening up and Development of New Lands.

EDITED BY

GRENVILLE A. J. COLE, M.R.I.A., F.G.S.,

Professor of Geology in the Royal College of Science for Ireland.

Large Crown 8vo, Cloth or Leather, with Illustrations.

VOL. 1.—PROSPECTING FOR MINERALS. By S. HERBERT COX, Assoc.R.S.M., M.Inst.M.M., F.G.S. Cloth, 5s.; Leather, rounded corners, 6s. 6d.

"If the succeeding volumes of the NEW LAND SERIES are equal in merit to the First, we must congratulate the Publishers on successfully filling up a gap in existing literature." —*Mining Journal.*

VOL. 2.—FOOD SUPPLY. By ROBERT BRUCE, Agricultural Superintendent to the Royal Dublin Society. With many Engravings and Photographs. Cloth, 4s. 6d.

"Bristles with information."—*Farmers' Gazette.*

IN PREPARATION.

VOL. 3.—NEW LANDS AND THEIR PROSPECTIVE ADVANTAGES. By HUGH ROBERT MILL, D.Sc., F.R.S.E., Librarian to the Royal Geographical Society.

VOL 4.—BUILDING CONSTRUCTION IN WOOD, STONE, AND CONCRETE. By JAS. LYON, M.A., Professor of Engineering in the Royal College of Science for Ireland; sometime Superintendent of the Engineering Department in the University of Cambridge; and J. TAYLOR, A.R.C.S.I.

*** Other Volumes will follow, dealing with subjects of PRIMARY IMPORTANCE in the EXAMINATION and UTILISATION of Lands which have not as yet been fully developed.

GRIFFIN'S "NEW LAND" SERIES.

Now Ready. With Illustrations. Price in Cloth, 5s.; *strongly bound in Leather,* 6s. 6d.

PROSPECTING FOR MINERALS.

A Practical Handbook for Prospectors, Explorers, Settlers, and all interested in the Opening up and Development of New Lands.

BY

S. HERBERT COX, Assoc.R.S.M., M.Inst.M.M., F.G.S., &c.

GENERAL CONTENTS.—Introduction and Hints on Geology—The Determination of Minerals: Use of the Blow-pipe, &c.—Rock-forming Minerals and Non-Metallic Minerals of Commercial Value: Rock Salt, Borax, Marbles, Lithographic Stone, Quartz and Opal, &c., &c.—Precious Stones and Gems—Stratified Deposits: Coal and Ores—Mineral Veins and Lodes—Irregular Deposits—Dynamics of Lodes: Faults, &c.—Alluvial Deposits—Noble Metals: Gold, Platinum, Silver, &c.—Lead—Mercury—Copper—Tin—Zinc—Iron—Nickel, &c.—Sulphur, Antimony, Arsenic, &c.—Combustible Minerals—Petroleum—General Hints on Prospecting—Glossary—Index.

"This ADMIRABLE LITTLE WORK . . . written with SCIENTIFIC ACCURACY in a CLEAR and LUCID style. . . . AN IMPORTANT ADDITION to technical literature . . . will be of value not only to the Student, but to the experienced Prospector."—*Mining Journal.*

NOW READY. Vol. II. With many Engravings and Photographs. Cloth, 4s. 6d.

FOOD SUPPLY.

BY ROBERT BRUCE,

Agricultural Superintendent to the Royal Dublin Society.

With Appendix on Preserved Foods by C. A. MITCHELL, B.A., F.I.C.

GENERAL CONTENTS.—Climate and Soil—Drainage and Rotation of Crops—Seeds and Crops—Vegetables and Fruits—Cattle and Cattle-Breeding—Sheep and Sheep Rearing—Pigs—Poultry—Horses—The Dairy—The Farmer's Implements—The Settler's Home.

"BRISTLES WITH INFORMATION."—*Farmers' Gazette.*

SECOND EDITION. *With Illustrations. Cloth,* 3s. 6d.

GETTING GOLD:

A GOLD-MINING HANDBOOK FOR PRACTICAL MEN.

BY J. C. F. JOHNSON, F.G.S., A.I.M.E.,

Life Member Australasian Mine-Managers' Association.

GENERAL CONTENTS.—Introductory: Getting Gold—Gold Prospecting (Alluvial and General)—Lode or Reef Prospecting—The Genesiology of Gold—Auriferous Lodes—Auriferous Drifts—Gold Extraction—Secondary Processes and Lixiviation—Calcination or "Roasting" of Ores—Motor Power and its Transmission—Company Formation and Operations—Rules of Thumb: Mining Appliances and Methods—Selected Data for Mining Men—Australasian Mining Regulations.

"PRACTICAL from beginning to end . . . deals thoroughly with the Prospecting, Sinking, Crushing, and Extraction of gold."—*Brit. Australasian.*

LONDON: CHARLES GRIFFIN & CO., LIMITED, EXETER STREET, STRAND.

ORE & STONE MINING.

BY

C. LE NEVE FOSTER, D.Sc., F.R.S.,

PROFESSOR OF MINING, ROYAL COLLEGE OF SCIENCE H.M. INSPECTOR OF MINES.

THIRD EDITION. With Frontispiece and 716 Illustrations. 34s.

"Dr. Foster's book was expected to be EPOCH-MAKING, and it fully justifies such expectation. . . . A MOST ADMIRABLE account of the mode of occurrence of practically ALL KNOWN MINERALS. Probably stands UNRIVALLED for completeness."—*The Mining Journal.*

GENERAL CONTENTS.

INTRODUCTION. Mode of Occurrence of Minerals: Classification: Tabular Deposits, Masses—Examples: Alum, Amber, Antimony, Arsenic, Asbestos, Asphalt, Barytes, Borax, Boric Acid, Carbonic Acid, Clay, Cobalt Ore, Copper Ore, Diamonds, Flint, Freestone, Gold Ore, Graphite, Gypsum, Ice, Iron Ore, Lead Ore, Manganese Ore, Mica, Natural Gas, Nitrate of Soda, Ozokerite, Petroleum, Phosphate of Lime, Potassium Salts, Quicksilver Ore, Salt, Silver Ore, Slate, Sulphur, Tin Ore, Zinc Ore. **Faults. Prospecting:** Chance Discoveries—Adventitious Finds—Geology as a Guide to Minerals—Associated Minerals—Surface Indications. **Boring:** Uses of Bore-holes—Methods of Boring Holes: i. By Rotation, ii. By Percussion with Rods, iii. By Percussion with Rope. **Breaking Ground:** Hand Tools—Machinery—Transmission of Power—Excavating Machinery: i. Steam Diggers, ii. Dredges, iii. Rock Drills, iv. Machines for Cutting Grooves, v. Machines for Tunnelling—Modes of using Holes—Driving and Sinking—Fire-setting—Excavating by Water. **Supporting Excavations:** Timbering—Masonry—Metallic Supports—Watertight Linings—Special Processes. **Exploitation:** Open Works:—Hydraulic Mining—Excavation of Minerals under Water—Extraction of Minerals by Wells and Bore-holes—Underground Workings—Beds—Veins—Masses. **Haulage or Transport:** Underground: by Shoots, Pipes, Persons, Sledges, Vehicles, Railways, Machinery, Boats—Conveyance above Ground. **Hoisting or Winding:** Motors, Drums, and Pulley Frames—Ropes, Chains, and Attachments—Receptacles—Other Appliances—Safety Appliances—Testing Ropes—Pneumatic Hoisting. **Drainage:** Surface Water—Dams—Drainage Tunnels—Siphons—Winding Machinery—Pumping Engines above ground—Pumping Engines below ground—Co-operative Pumping. **Ventilation:** Atmosphere of Mines—Causes of Pollution of Air—Natural Ventilation—Artificial Ventilation: i. Furnace Ventilation, ii. Mechanical Ventilation—Testing the Quality of Air—Measuring the Quantity and Pressure of the Air—Efficiency of Ventilating Appliances—Resistance caused by Friction. **Lighting:** Reflected Daylight—Candles—Torches—Lamps—Wells Light—Safety Lamps—Gas—Electric Light. **Descent and Ascent:** Steps and Slides—Ladders—Buckets and Cages—Man Engine. **Dressing:** i. Mechanical Processes—ii. Processes depending on Physical Properties—iii. Chemical Processes—**Principles of Employment of Mining Labour—Legislation affecting Mines and Quarries. Condition of the Miner—Accidents.**

"This EPOCH-MAKING work . . . appeals to MEN OF EXPERIENCE no less than to students."—*Berg- und Hüttenmännische Zeitung.*

"This SPLENDID WORK."—*Oesterr. Ztschrft. für Berg- und Hüttenwesen.*

ELEMENTARY MINING AND QUARRYING

(An Introductory Text-book).

BY PROF. C. LE NEVE FOSTER, F.R.S.

In Crown 8vo. With Illustrations. [*Shortly.*

COAL-MINING (A Text-Book of):

FOR THE USE OF COLLIERY MANAGERS AND OTHERS ENGAGED IN COAL-MINING.

BY

HERBERT WILLIAM HUGHES, F.G.S.,
Assoc. Royal School of Mines, General Manager of Sandwell Park Colliery.

THIRD EDITION. *In Demy 8vo, Handsome Cloth. With very Numerous Illustrations, mostly reduced from Working Drawings. Price* 18*s.*

"The details of colliery work have been fully described, on the ground that collieries are more often made REMUNERATIVE by PERFECTION IN SMALL MATTERS than by bold strokes of engineering. . . . It frequently happens, in particular localities, that the adoption of a combination of small improvements, any of which viewed separately may be of apparently little value, turns an unprofitable concern into a paying one."—*Extract from Author's Preface.*

GENERAL CONTENTS.

Geology: Rocks -Faults—Order of Succession—Carboniferous System in Britain. **Coal**: Definition and Formation of Coal—Classification and Commercial Value of Coals. **Search for Coal**: Boring—various appliances used—Devices employed to meet Difficulties of deep Boring—Special methods of Boring—Mather & Platt's, American, and Diamond systems—Accidents in Boring—Cost of Boring—Use of Boreholes. **Breaking Ground**: Tools—Transmission of Power Compressed Air, Electricity—Power Machine Drills—Coal Cutting by Machinery—Cost of Coal Cutting—Explosives—Blasting in Dry and Dusty Mines—Blasting by Electricity—Various methods to supersede Blasting. **Sinking**: Position, Form, and Size of shaft—Operation of getting down to "Stone-head"—Method of proceeding afterwards—Lining shafts—Keeping out Water by Tubbing—Cost of Tubbing—Sinking by Boring—Kind-Chaudron, and Lipmann methods—Sinking through Quicksands—Cost of Sinking. **Preliminary Operations**: Driving underground Roads—Supporting Roof: Timbering, Chocks or Cogs, Iron and Steel Supports and Masonry—Arrangement of Inset. **Methods of Working**: Shaft, Pillar, and Subsidence—Bord and Pillar System—Lancashire Method—Longwall Method—Double Stall Method—Working Steep Seams—Working Thick Seams—Working Seams lying near together—Spontaneous Combustion. **Haulage**: Rails—Tubs—Haulage by Horses—Self-acting Inclines—Direct-acting Haulage—Main and Tail Rope—Endless Chain-Endless Rope—Comparison. **Winding**: Pit Frames—Pulleys—Cages—Ropes—Guides—Engines—Drums—Brakes—Counterbalancing—Expansion—Condensation—Compound Engines—Prevention of Overwinding—Catches at pit top—Changing Tubs—Tub Controllers—Signalling. **Pumping**: Bucket and Plunger Pumps—Supporting Pipes in Shaft—Valves—Suspended lifts for Sinking—Cornish and Bull Engines—Davey Differential Engine—Worthington Pump—Calculations as to size of Pumps—Draining Deep Workings—Dams. **Ventilation**: Quantity of air required—Gases met with in Mines—Coal-dust—Laws of Friction—Production of Air-currents—Natural Ventilation—Furnace Ventilation—Mechanical Ventilators—Efficiency of Fans—Comparison of Furnaces and Fans—Distribution of the Air-current—Measurement of Air-currents. **Lighting**: Naked Lights—Safety Lamps—Modern Lamps—Conclusions—Locking and Cleaning Lamps—Electric Light Underground—Delicate Indicators. **Works at Surface**: Boilers—Mechanical Stoking—Coal Conveyors—Workshops. **Preparation of Coal for Market**: General Considerations—Tipplers—Screens—Varying the Sizes made by Screens—Belts—Revolving Tables—Loading Shoots—Typical Illustrations of the arrangement of Various Screening Establishments—Coal Washing—Dry Coal Cleaning—Briquettes.

"Quite THE BEST BOOK of its kind . . . as PRACTICAL in aim as a book can be . . . touches upon every point connected with the actual working of collieries. The illustrations are EXCELLENT."—*Athenæum.*

"A Text-book on Coal-Mining is a great desideratum, and Mr. HUGHES possesses ADMIRABLE QUALIFICATIONS for supplying it. . . . We cordially recommend the work."—*Colliery Guardian.*

"Mr. HUGHES has had opportunities for study and research which fall to the lot of but few men. If we mistake not, his text-book will soon come to be regarded as the STANDARD WORK of its kind."—*Birmingham Daily Gazette.*

PETROLEUM

AND ITS PRODUCTS:

A PRACTICAL TREATISE.

BY

BOVERTON REDWOOD,
F.R.S.E., F.I.C., ASSOC. INST. C.E.,
Hon. Corr. Mem. of the Imperial Russian Technical Society; Mem. of the American Chemical Society; Consulting Adviser to the Corporation of London under the Petroleum Acts, &c., &c.

ASSISTED BY GEO. T. HOLLOWAY, F.I.C., ASSOC. R.C.S.,
And Numerous Contributors.

In Two Volumes, Large 8vo. Price 45s.

With Numerous Maps, Plates, and Illustrations in the Text.

GENERAL CONTENTS.

I. General Historical Account of the Petroleum Industry.
II. Geological and Geographical Distribution of Petroleum and Natural Gas.
III. Chemical and Physical Properties of Petroleum.
IV. Origin of Petroleum and Natural Gas.
V. Production of Petroleum, Natural Gas, and Ozokerite.
VI. The Refining of Petroleum.
VII. The Shale Oil and Allied Industries.
VIII. Transport, Storage, and Distribution of Petroleum.
IX. Testing of Petroleum.
X. Application and Uses of Petroleum.
XI. Legislation on Petroleum at Home and Abroad.
XII. Statistics of the Petroleum Production and the Petroleum Trade, obtained from the most trustworthy and official sources.

"The MOST COMPREHENSIVE AND CONVENIENT ACCOUNT that has yet appeared of a gigantic industry which has made incalculable additions to the comfort of civilised man. . . . The chapter dealing with the arrangement for STORAGE and TRANSPORT of GREAT PRACTICAL INTEREST. . . . The DIGEST of LEGISLATION on the subject cannot but prove of the GREATEST UTILITY."—*The Times.*

"A SPLENDID CONTRIBUTION to our technical literature."—*Chemical News.*

"This THOROUGHLY STANDARD WORK . . . in every way EXCELLENT . . most fully and ably handled . . . could only have been produced by a man in the very exceptional position of the Author. . . . INDISPENSABLE to all who have to do with Petroleum, its APPLICATIONS, MANUFACTURE, STORAGE, or TRANSPORT."—*Mining Journal.*

"We must concede to Mr. Redwood the distinction of having produced a treatise which must be admitted to the rank of THE INDISPENSABLES. It contains THE LAST WORD that can be said about Petroleum in any of its SCIENTIFIC, TECHNICAL, and LEGAL aspects. It would be difficult to conceive of a more comprehensive and explicit account of the geological conditions associated with the SUPPLY of Petroleum and the very practical question of its AMOUNT and DURATION."—*Journal of Gas Lighting.*

MINE-SURVEYING (A Treatise on):

For the use of Managers of Mines and Collieries, Students at the Royal School of Mines, &c.

BY BENNETT H. BROUGH, F.G.S., ASSOC.R.S.M.,

Formerly Instructor of Mine-Surveying, Royal School of Mines.

SEVENTH EDITION, Enlarged and Revised. With Numerous Diagrams. Cloth, 7s. 6d.

GENERAL CONTENTS.

General Explanations—Measurement of Distances—Miner's Dial—Variation of the Magnetic-Needle—Surveying with the Magnetic-Needle in presence of Iron—Surveying with the Fixed Needle—German Dial—Theodolite—Traversing Underground—Surface-Surveys with Theodolite—Plotting the Survey—Calculation of Areas—Levelling—Connection of Underground- and Surface-Surveys—Measuring Distances by Telescope—Setting-out—Mine-Surveying Problems—Mine Plans—Applications of Magnetic-Needle in Mining—Photographic Surveying—*Appendices.*

"Has PROVED itself a VALUABLE Text-book; the BEST, if not the only one, in the English language on the subject."—*Mining Journal.*

"No English-speaking Mine Agent or Mining Student will consider his technical library complete without it."—*Nature.*

"A valuable accessory to Surveyors in every department of commercial enterprise. Fully deserves to hold its position as a STANDARD."—*Colliery Guardian.*

In Large 8vo, with Illustrations and Folding-Plates. 10s. 6d.

BLASTING:

AND THE USE OF EXPLOSIVES.

A Handbook for Engineers and others Engaged in Mining, Tunnelling, Quarrying, &c.

BY OSCAR GUTTMANN, ASSOC. M. INST. C.E.

Member of the Societies of Civil Engineers and Architects of Vienna and Budapest, Corresponding Member of the Imp. Roy. Geological Institution of Austria, &c.

GENERAL CONTENTS.—Historical Sketch—Blasting Materials—Blasting Powder—Various Powder-mixtures—Gun-cotton—Nitro-glycerine and Dynamite—Other Nitro-compounds—Sprengel's Liquid (acid) Explosives—Other Means of Blasting—Qualities, Dangers, and Handling of Explosives—Choice of Blasting Materials—Apparatus for Measuring Force—Blasting in Fiery Mines—Means of Igniting Charges—Preparation of Blasts—Bore-holes—Machine-drilling—Chamber Mines—Charging of Bore-holes—Determination of the Charge—Blasting in Bore-holes—Firing—Straw and Fuze Firing—Electrical Firing—Substitutes for Electrical Firing—Results of Working—Various Blasting Operations—Quarrying—Blasting Masonry, Iron and Wooden Structures—Blasting in earth, under water, of ice, &c.

"This ADMIRABLE work."—*Colliery Guardian.*

"Should prove a *vade-mecum* to Mining Engineers and all engaged in practical work. —*Iron and Coal Trades Review.*

LONDON: CHARLES GRIFFIN & CO., LIMITED, EXETER STREET, STRAND.

NEW VOLUME OF GRIFFIN'S MINING SERIES.

Edited by C. LE NEVE FOSTER, D.Sc., F.R.S.,
H.M. Inspector of Mines, Professor of Mining, Royal School of Mines.

Mine Accounts and Mining Book-keeping,

A Manual for the Use of Students, Managers of Metalliferous Mines and Collieries, Secretaries of Mining Companies, and others interested in Mining.

WITH NUMEROUS EXAMPLES TAKEN FROM THE ACTUAL PRACTICE OF LEADING MINING COMPANIES THROUGHOUT THE WORLD.

BY

JAMES GUNSON LAWN, Assoc. R.S.M., Assoc. Mem. Inst. C.E., F.G.S.,
Professor of Mining at the South African School of Mines, Capetown, Kimberley, and Johannesburg.

In Large 8vo. Price 10s. 6d.

GENERAL CONTENTS.—**Introduction. Part I. Engagement and Payment of Workmen**—Data Determining Gross Amount due to Workmen—A. Length of Time Worked—Overtime—B. Amount of Work done—Sinking and Driving—Exploitation—Sliding Scales—Modifications—C. Value of Mineral gotten—Deductions—Pay-Sheets, Due-Bills, and Pay-Tickets. **Part II. Purchases and Sales**—Purchase and Distribution of Stores—Books and Forms Relating thereto—Sales of Product—Methods of Sale—Contract—Tender—Delivery of, and Payment for, Mineral—Tin Ore—Coal—Silver Ore—Gold Ore **Part III. Working Summaries and Analyses**—Summaries of Minerals Raised, Dressed, and Sold; and of Labour—Analyses of Costs—Accounts Forwarded to Head Office. **Part IV. Ledger, Balance Sheet, and Company Books**—Head Office Books—Ledger—Principal Accounts of a Mining Company—Capital Account—Sale and Purchase Accounts—Capital Expenditure—Personal—Stores—Wages Account—Bad Debts Account—Cash Account—Bills Receivable and Payable Account—Discount and Interest Account—Product Account—Working Accounts—Profit and Loss Account—Journal—Inventory—Balance Sheet—Bibliography—Redemption of Capital—1. Debentures—2. Sinking Fund—A. By Equal Annual Sums—B. By Annual Sum varying according to a Formula—C. By Annual Sum depending on Mineral worked—3. Enlarged Dividends or Bonuses—Depreciation—Reserve Fund—Bibliography—General Considerations and Companies Books—Private Individuals—Private Partnership Companies—Cost-book Companies—Limited Liability Companies—Stocks and Shares—Debentures—Books connected with Shares—Miscellaneous Books—Bibliography. **Part V. Reports and Statistics**—Inspections of Workings and Machinery—A. Colliery Reports, &c.—Inspections—Report Books—Measurement of Ventilating Current—Permits to fire Shots and carry Safety Lamp Key—B. Ore Mine Reports, &c—C. Miscellaneous Reports, &c.—Reports of Mining Companies—Managers' Reports—Diagrams—Tabular Statements—Reports of Directors—Reports of Cost-book Mines—Mining Statistics—Great Britain—Other Countries—Bibliography.

"It seems IMPOSSIBLE to suggest how Mr. LAWN's book could be made more COMPLETE or more VALUABLE, careful, and exhaustive."—*Accountants' Magazine.*

"MR. LAWN's book should be found of GREAT USE by MINE SECRETARIES and MINE MANAGERS. It consists of five Parts. PART 1 is devoted to the engagement and payment of workmen, and contains forms of contracts and pay sheets of various descriptions in use by Mining Companies in England and South Africa. Special reference is made to pay sheets and forms employed by the DE BEERS CONSOLIDATED MINES, to the General Manager and the late Secretary of which Company the author is indebted for the particulars given. PART 2 is taken up by a description of books and forms relating to the purchases of Stores, &c., and to sales of the Products of the mines. PART 3 is the most important section of the book, containing instructive details of the manner of obtaining summaries of Working Expenditure and Analyses of Costs. The forms used in this connection by the De Beers Company are shown *in extenso.* PART 4 consists of the Bookkeeping, properly so-called, of a mining company. All details concerning the ledger, journal, and other books, and the principal working accounts of a mine are given. There are some very interesting formulæ in this section, showing the manner in which the CAPITAL of a company should be REDEEMED and REPAID to its Shareholders. According to this manual there are three ways in which this extremely desirable end may be arrived at. . . . The book is published at half a guinea, a price low enough considering the amount of information and instruction set forth."—*Johannesburg Star.*

THIRD EDITION. With Folding Plates and Many Illustrations.
Large 8vo. Handsome Cloth. 36s.

ELEMENTS OF METALLURGY:

A PRACTICAL TREATISE ON THE ART OF EXTRACTING METALS FROM THEIR ORES.

BY

J. ARTHUR PHILLIPS, M.INST.C.E., F.C.S., F.G.S., &c.

AND

H. BAUERMAN, V.P.G.S.

GENERAL CONTENTS.

Refractory Materials.	Antimony.	Iron.
Fire-Clays.	Arsenic.	Cobalt.
Fuels, &c.	Zinc.	Nickel.
Aluminium.	Mercury.	Silver.
Copper.	Bismuth.	Gold.
Tin.	Lead.	Platinum.

*** Many NOTABLE ADDITIONS, dealing with new Processes and Developments, will be found in the Third Edition.

"Of the THIRD EDITION, we are still able to say that, as a Text-book of Metallurgy, it is THE BEST with which we are acquainted."—*Engineer*.

"The value of this work is almost *inestimable*. There can be no question that the amount of time and labour bestowed on it is enormous. . . . There is certainly no Metallurgical Treatise in the language calculated to prove of such general utility."—*Mining Journal*.

"In this most useful and handsome volume is condensed a large amount of valuable practical knowledge. A careful study of the first division of the book, on Fuels, will be found to be of great value to every one in training for the practical applications of our scientific knowledge to any of our metallurgical operations."—*Athenæum*.

"A work which is equally valuable to the Student as a Text-book, and to the practical Smelter as a Standard Work of Reference. . . . The Illustrations are admirable examples of Wood Engraving."—*Chemical News*.

LONDON: CHARLES GRIFFIN & CO., LIMITED, EXETER STREET, STRAND.

Griffin's Metallurgical Series.

STANDARD WORKS OF REFERENCE

FOR

Metallurgists, Mine-Owners, Assayers, Manufacturers, and all interested in the development of the Metallurgical Industries.

EDITED BY

Sir W. ROBERTS-AUSTEN, K.C.B., D.C.L., F.R.S.,

CHEMIST AND ASSAYER TO THE ROYAL MINT; PROFESSOR OF METALLURGY IN THE ROYAL COLLEGE OF SCIENCE.

In Large 8vo, Handsome Cloth. With Illustrations.

1. **INTRODUCTION to the STUDY of METALLURGY.** By the EDITOR. FOURTH EDITION. 15s. (See p. 63.)

2. **GOLD (The Metallurgy of).** By THOS. KIRKE ROSE, D.Sc., Assoc. R.S.M., F.I.C., of the Royal Mint. THIRD EDITION, 21s. (See p. 64.)

3. **IRON (The Metallurgy of).** By THOS. TURNER, Assoc. R.S.M., F.I.C., F.C.S. 16s. (See p. 65.)

Will be Published at Short Intervals.

4. **STEEL (The Metallurgy of).** By F. W. HARBORD, Assoc. R.S.M., F.I.C.

5. **LEAD AND SILVER (The Metallurgy of).** By H. F. COLLINS, Assoc. R.S.M., M.Inst.M.M. Part I., Lead; Part II., Silver.

6. **METALLURGICAL MACHINERY:** the Application of Engineering to Metallurgical Problems. By HENRY CHARLES JENKINS, Wh.Sc., Assoc. R.S.M., Assoc.M.Inst.C.E., of the Royal College of Science.

7. **ALLOYS.** By the EDITOR.

*** Other Volumes in Preparation.

GRIFFIN'S METALLURGICAL SERIES.

FOURTH EDITION, Revised and Enlarged. Price 15s.

AN INTRODUCTION TO THE STUDY

OF

METALLURGY.

BY

Sir W. ROBERTS-AUSTEN, K.C.B., D.C.L., F.R.S.,

Associate of the Royal School of Mines; Chemist and Assayer of the Royal Mint; Professor of Metallurgy in the Royal College of Science.

In Large 8vo, with numerous Illustrations and Micro-Photographic Plates of different varieties of Steel.

GENERAL CONTENTS

The Relation of Metallurgy to Chemistry.
Physical Properties of Metals.
Alloys.
The Thermal Treatment of Metals.
Fuel and Thermal Measurements.
Materials and Products of Metallurgical Processes
Furnaces.
Means of Supplying Air to Furnaces.
Thermo-Chemistry.
Typical Metallurgical Processes.
The Micro-Structure of Metals and Alloys.
Economic Considerations.

"No English text-book at all approaches this in the COMPLETENESS with which the most modern views on the subject are dealt with. Professor Austen's volume will be INVALUABLE, not only to the student, but also to those whose knowledge of the art is far advanced."—*Chemical News.*

"INVALUABLE to the student. . . . Rich in matter not to be readily found elsewhere."—*Athenæum.*

"This volume amply realises the expectations formed as to the result of the labours of so eminent an authority. It is remarkable for its ORIGINALITY of conception and for the large amount of information which it contains. . . . We recommend every one who desires information not only to consult, but to STUDY this work."—*Engineering.*

"Will at once take FRONT RANK as a text-book."—*Science and Art.*

"Prof. ROBERTS-AUSTEN's book marks an epoch in the history of the teaching of metallurgy in this country."—*Industries.*

LONDON: CHARLES GRIFFIN & CO., LIMITED, EXETER STREET, STRAND.

GRIFFIN'S METALLURGICAL SERIES.

THIRD EDITION. Revised and Enlarged. Handsome Cloth. 21s.

THE METALLURGY OF GOLD.

BY

T. KIRKE ROSE, D.Sc.Lond., Assoc.R.S.M.,

Assistant Assayer of the Royal Mint.

Revised and partly Re-written. Including the most recent Improvements in the Cyanide Process. With Frontispiece and numerous Illustrations.

GENERAL CONTENTS.

The Properties of Gold and its Alloys.
Chemistry of the Compounds of Gold.
Mode of Occurrence and Distribution of Gold.
Placer Mining.
Shallow Deposits.
Deep Placer Mining.
Quartz Crushing in the Stamp Battery.
Amalgamation in the Stamp Battery.
Other Forms of Crushing and Amalgamating Machinery.
Concentration in Stamp Mills.
Stamp Battery Practice in particular Localities.
Chlorination: The Preparation of Ore for Treatment.
Chlorination: The Vat Process.
Chlorination: The Barrel Process.
Chlorination Practice in particular Mills.
The Cyanide Process.
Chemistry of the Cyanide Process.
Pyritic Smelting.
The Refining and Parting of Gold Bullion.
The Assay of Gold Ores.
The Assay of Gold Bullion.
Economic Considerations.
Bibliography.

"A COMPREHENSIVE PRACTICAL TREATISE on this important subject."—*The Times.*

"The MOST COMPLETE description of the CHLORINATION PROCESS which has yet been published."—*Mining Journal.*

"Dr. Rose gained his experience in the Western States of America, but he has secured details of gold-working from ALL PARTS of the world, and these should be of GREAT SERVICE to practical men. . . . The four chapters on *Chlorination*, written from the point of view alike of the practical man and the chemist, TEEM WITH CONSIDERATIONS HITHERTO UNRECOGNISED, and constitute an addition to the literature of Metallurgy, which will prove to be of classical value."—*Nature.*

"Adapted for all who are interested in the Gold Mining Industry, being free from technicalities as far as possible, but is more particularly of value to those engaged in the industry—viz., mill-managers, reduction-officers, &c."—*Cape Times.*

GRIFFIN'S METALLURGICAL SERIES.

THE METALLURGY OF IRON.

BY THOMAS TURNER, ASSOC.R.S.M., F.I.C.,
Director of Technical Instruction to the Staffordshire County Council.

IN LARGE 8VO, HANDSOME CLOTH, WITH NUMEROUS ILLUSTRATIONS (MANY FROM PHOTOGRAPHS). PRICE 16s.

General Contents.—Early History of Iron.—Modern History of Iron.—The Age of Steel.—Chief Iron Ores.—Preparation of Iron Ores.—The Blast Furnace.—The Air used in the Blast Furnace.—Reactions of the Blast Furnace.—The Fuel used in the Blast Furnace.—Slags and Fluxes of Iron Smelting.—Properties of Cast Iron.—Foundry Practice.—Wrought Iron.—Indirect Production of Wrought Iron.—The Puddling Process.—Further Treatment of Wrought Iron.—Corrosion of Iron and Steel.

"A MOST VALUABLE SUMMARY of knowledge relating to every method and stage in the manufacture of cast and wrought iron . . . rich in chemical details. . . . EXHAUSTIVE and THOROUGHLY UP-TO-DATE."—*Bulletin of the American Iron and Steel Association.*

"This is A DELIGHTFUL BOOK, giving, as it does, reliable information on a subject becoming every day more elaborate."—*Colliery Guardian.*

"A THOROUGHLY USEFUL BOOK, which brings the subject UP TO DATE. OF GREAT VALUE to those engaged in the iron industry."—*Mining Journal.*

IN PREPARATION.

COMPANION-VOLUME ON

THE METALLURGY OF STEEL.

By F. W. HARBORD, ASSOC.R.S.M., F.I.C.

Ready Shortly, Important New Work.

THE METALLURGY OF LEAD AND SILVER.

BY H. F. COLLINS, ASSOC.R.S.M., M.INST.M.M.

In Two Volumes, Each complete in Itself.

Part I.—LEAD.

A Complete and Exhaustive Treatise on
THE MANUFACTURE OF LEAD,
WITH SECTIONS ON
SMELTING AND DESILVERISATION,
And Chapters on the Assay and Analysis of the Materials Involved.

To be followed by the Companion-Volume (Part II.) on SILVER.

LONDON: CHARLES GRIFFIN & CO., LIMITED, EXETER STREET, STRAND.

ASSAYING (A Text-Book of):

For the use of Students, Mine Managers, Assayers, &c.

BY J. J. BERINGER, F.I.C., F.C.S.,
Public Analyst for, and Lecturer to the Mining Association of, Cornwall.

AND C. BERINGER, F.C.S.,
Late Chief Assayer to the Rio Tinto Copper Company, London,

With numerous Tables and Illustrations. Crown 8vo. Cloth, 10/6.
FIFTH EDITION; Revised.

GENERAL CONTENTS. — PART I. — INTRODUCTORY: MANIPULATION: Sampling; Drying; Calculation of Results—Laboratory-books and Reports. METHODS: Dry Gravimetric; Wet Gravimetric—Volumetric Assays: Titrometric, Colorimetric, Gasometric—Weighing and Measuring—Reagents—Formulæ, Equations, &c.—Specific Gravity.

PART II.—METALS: Detection and Assay of Silver, Gold, Platinum, Mercury, Copper, Lead, Thallium, Bismuth, Antimony, Iron, Nickel, Cobalt, Zinc, Cadmium, Tin, Tungsten, Titanium, Manganese, Chromium, &c.—Earths, Alkalies.

PART III.—NON-METALS: Oxygen and Oxides; The Halogens—Sulphur and Sulphates—Arsenic, Phosphorus, Nitrogen—Silicon, Carbon, Boron—Useful Tables.

"A REALLY MERITORIOUS WORK, that may be safely depended upon either for systematic instruction or for reference."—*Nature.*

"This work is one of the BEST of its kind. . . . Contains all the information that the Assayer will find necessary in the examination of minerals."—*Engineer.*

Handsome Cloth. With Numerous Illustrations. 6s.

ELEMENTARY METALLURGY

(A TEXT-BOOK OF).

Including the Author's PRACTICAL LABORATORY COURSE.

BY A. HUMBOLDT SEXTON, F.I.C., F.C.S.,
Professor of Metallurgy in the Glasgow and West of Scotland Technical College.

GENERAL CONTENTS.—Introduction—Properties of the Metals—Combustion—Fuels—Refractory Materials—Furnaces—Occurrence of the Metals in Nature—Preparation of the Ore for the Smelter—Metallurgical Processes—Iron: Preparation of Pig Iron—Malleable Iron—Steel—Mild Steel—Copper—Lead—Zinc and Tin—Silver—Gold—Mercury—Alloys—Applications of ELECTRICITY to Metallurgy—LABORATORY COURSE WITH NUMEROUS PRACTICAL EXERCISES.

"Just the kind of work for Students COMMENCING the study of Metallurgy, or for ENGINEERING Students requiring a GENERAL KNOWLEDGE of it, or for ENGINEERS in practice who like a HANDY WORK of REFERENCE. To all three classes we HEARTILY commend the work."—*Practical Engineer.*

"EXCELLENTLY got-up and WELL-ARRANGED. . . . Iron and copper well explained by EXCELLENT diagrams showing the stages of the process from start to finish. . . . The most NOVEL chapter is that on the many changes wrought in Metallurgical Methods by ELECTRICITY."—*Chemical Trade Journal.*

"Possesses the GREAT ADVANTAGE of giving a COURSE OF PRACTICAL WORK."—*Mining Journal.*

In large 8vo. With Numerous Illustrations and Three Folding-Plates.
Price 21s.

ELECTRIC SMELTING & REFINING:

A Practical Manual of the Extraction and Treatment of Metals by Electrical Methods.

Being the "ELEKTRO-METALLURGIE" of DR. W. BORCHERS.

Translated from the Second Edition by WALTER G. McMILLAN, F.I.C., F.C.S.,

Secretary to the Institution of Electrical Engineers; late Lecturer in Metallurgy at Mason College, Birmingham.

CONTENTS.

PART I.—ALKALIES AND ALKALINE EARTH METALS: Magnesium, Lithium, Beryllium, Sodium, Potassium, Calcium, Strontium, Barium, the Carbides of the Alkaline Earth Metals.

PART II.—THE EARTH METALS: Aluminium, Cerium, Lanthanum, Didymium.

PART III.—THE HEAVY METALS: Copper, Silver, Gold, Zinc and Cadmium, Mercury, Tin, Lead, Bismuth, Antimony, Chromium, Molybdenum, Tungsten, Uranium, Manganese, Iron, Nickel, and Cobalt, the Platinum Group.

"COMPREHENSIVE and AUTHORITATIVE . . . not only FULL of VALUABLE INFORMATION, but gives evidence of a THOROUGH INSIGHT into the technical VALUE and POSSIBILITIES of all the methods discussed."—*The Electrician.*

"Dr. BORCHERS' WELL-KNOWN WORK . . . must OF NECESSITY BE ACQUIRED by every one interested in the subject. EXCELLENTLY put into English with additional matter by Mr. McMILLAN."—*Nature.*

"Will be of GREAT SERVICE to the practical man and the Student."—*Electric Smelting.*

In Large 8vo. Handsome Cloth. Price 4s.

TABLES FOR QUANTITATIVE METALLURGICAL ANALYSIS.

FOR LABORATORY USE.

BY J. JAMES MORGAN, F.C.S.,
Member Soc. Chem. Industry, Member Cleveland Institute of Engineers.

SUMMARY OF CONTENTS.—Iron Ores.—Steel.—Limestone, &c.—Boiler Incrustations, Clays, and Fire-bricks.—Blast Furnace Slag, &c.—Coal, Coke, and Patent Fuel.—Water.—Gases.—Copper.—Zinc.—Lead.—Alloys.—White Lead.—Atomic Weights.—Factors.—Reagents, &c.

*** The above work contains several NOVEL FEATURES, notably the extension, to quantitative analysis, of the PRINCIPLES OF 'GROUP' SEPARATIONS, hitherto chiefly confined to Qualitative work, and will be found to FACILITATE GREATLY the operations of CHEMISTS, ASSAYERS, and others.

LONDON: CHARLES GRIFFIN & CO., LIMITED, EXETER STREET, STRAND.

SECOND EDITION at Press.

ELECTRO-METALLURGY

(A TREATISE ON):

Embracing the Application of Electrolysis to the Plating, Depositing, Smelting, and Refining of various Metals, and to the Reproduction of Printing Surfaces and Art-Work, &c.

BY

WALTER G. McMILLAN, F.I.C., F.C.S.

With numerous Illustrations. Large Crown 8vo. Cloth.

"This excellent treatise, . . . one of the BEST and MOST COMPLETE manuals hitherto published on Electro-Metallurgy."—*Electrical Review.*

"This work will be a STANDARD."—*Jeweller.*

"Any metallurgical process which REDUCES the COST of production must of necessity prove of great commercial importance. . . . We recommend this manual to ALL who are interested in the PRACTICAL APPLICATION of electrolytic processes."—*Nature.*

Large Crown 8vo. Cloth, 8s. 6d.

The Art of the Goldsmith and Jeweller

A Manual on the Manipulation of Gold in the Various Processes of Goldsmith's Work, and the Manufacture of Personal Ornaments. For Students and Practical Men.

BY THOS. B. WIGLEY,

Headmaster of the Jewellers and Silversmiths' Association Technical School, Birmingham.

ASSISTED BY

J. H. STANSBIE, B.Sc. (LOND.), F.I.C.,

Lecturer at the Birmingham Municipal Technical School.

In Large Crown 8vo. With Numerous Illustrations.

General Contents.—Introduction.—The Ancient Goldsmith's Art.—The Metallurgy of Gold.—Prices of Gold, Silver, &c.—Preparation of Alloys.—Melting of Gold.—Rolling and Slitting of Gold.—The Workshop and Tools.—Filigree Wire Drawing.—Manufacture of Personal Ornaments.—Finger Rings.—Mounting and Setting.—Mayoral Chains and Civic Insignia.—Antique Jewellery and its Revival.—Etruscan Work.—Manufacture of Gold Chains.—PRECIOUS STONES.—Cutting Diamonds and other Precious Gems.—Polishing and Finishing.—Chasing, Embossing, and Repoussé Work.—The Colouring and Finishing of Articles of Jewellery.—Enamelling: its History, Processes, and Applicability.—Heraldic Distinctions and Armorial Bearings.—Engraving: its Origin, History, and Processes.—Moulding and Casting of Ornaments, &c.—Fluxes, &c.—Recovery of the Precious Metals from the Waste Products.—Refining Semel and Assaying Semel Bars.—Gilding and Electro Deposition.—Hall-Marking Gold and Silver Plate.—Miscellaneous Useful Information.—Appendix: Technological Examinations.

---

§ 9. Griffin's Chemical and Technological Publications.

		PAGE
Inorganic Chemistry,	PROFS. DUPRÉ AND HAKE,	70
Quantitative Analysis,	PROF. HUMBOLDT SEXTON,	70
Qualitative ,,	,, ,,	70
Chemical Recreations,	J. J. GRIFFIN,	75
Chemistry for Engineers,	MM. BLOUNT AND BLOXAM,	71
,, ,, Manufacturers,	,, ,,	71
Tables for Chemists and Manufacturers,	PROF. CASTELL-EVANS,	75
Metallurgy and Electro-Metallurgy,	*See Previous Section.*	
Agricultural Chemistry,	PROF. J. M. MUNRO,	75
Dairy ,,	H. D. RICHMOND,	75
Foods, Analysis of,	A. WYNTER BLYTH,	72
Poisons, Detection of,	,,	72
Technical Mycology (The Fermentation Industries)	LAFAR AND SALTER,	79
Brewing,	DR. W. J. SYKES,	78
Cements,	G. R. REDGRAVE,	76
Gas Manufacture,	W. ATKINSON BUTTERFIELD,	74
Petroleum,	MM. REDWOOD AND HOLLOWAY,	58
Oils, Soaps, Candles,	DR. ALDER WRIGHT,	80
Lubricants and Lubrication,	MM. ARCHBUTT AND DEELEY,	80
Painters' Colours, Oils, and Varnishes,	G. H. HURST,	76
Painting and Decorating,	W. J. PEARCE,	77
Pharmacy,	WM. ELBORNE,	75
Photography,	A. BROTHERS,	73
The Textile Industries: Dyeing,	MM. KNECHT AND RAWSON,	81
,, and Cleaning,	G. H. HURST,	83
Bleaching and Calico-Printing,	GEO. DUERR,	83
Textile Printing,	SEYMOUR ROTHWELL,	82

INORGANIC CHEMISTRY

(A SHORT MANUAL OF).

BY

A. DUPRÉ, Ph.D., F.R.S.,

AND

WILSON HAKE, Ph.D., F.I.C., F.C.S.,

Of the Westminster Hospital Medical School.

SECOND EDITION, Revised. Crown 8vo. Cloth, 7s. 6d.

"A well-written, clear and accurate Elementary Manual of Inorganic Chemistry. . . . We agree heartily with the system adopted by Drs. Dupré and Hake. WILL MAKE EXPERIMENTAL WORK TREBLY INTERESTING BECAUSE INTELLIGIBLE."—*Saturday Review.*

"There is no question that, given the PERFECT GROUNDING of the Student in his Science, the remainder comes afterwards to him in a manner much more simple and easily acquired. The work IS AN EXAMPLE OF THE ADVANTAGES OF THE SYSTEMATIC TREATMENT of a Science over the fragmentary style so generally followed. BY A LONG WAY THE BEST of the small Manuals for Students."—*Analyst.*

LABORATORY HANDBOOKS BY A. HUMBOLDT SEXTON,

Professor of Metallurgy in the Glasgow and West of Scotland Technical College.

Sexton's (Prof.) Outlines of Quantitative Analysis.

FOR THE USE OF STUDENTS.

With Illustrations. FOURTH EDITION. Crown 8vo, Cloth, 3s.

"A COMPACT LABORATORY GUIDE for beginners was wanted, and the want has been WELL SUPPLIED. . . . A good and useful book."—*Lancet.*

Sexton's (Prof.) Outlines of Qualitative Analysis.

FOR THE USE OF STUDENTS.

With Illustrations. THIRD EDITION. Crown 8vo, Cloth, 3s. 6d.

"The work of a thoroughly practical chemist."—*British Medical Journal.*

"Compiled with great care, and will supply a want."—*Journal of Education.*

Sexton's (Prof.) Elementary Metallurgy:

Including the Author's Practical Laboratory Course. With many Illustrations, 6s. [See p. 66.

"Just the kind of work for students commencing the study of metallurgy."—*Practical Engineer.*

CHEMISTRY FOR ENGINEERS AND MANUFACTURERS.

A PRACTICAL TEXT-BOOK.

BY

BERTRAM BLOUNT, F.I.C., F.C.S., Assoc.Inst.C.E., Consulting Chemist to the Crown Agents for the Colonies.

AND

A. G. BLOXAM, F.I.C., F.C.S., Consulting Chemist, Head of the Chemistry Department, Goldsmiths' Inst., New Cross.

With Illustrations. In Two Vols., Large 8vo. Sold Separately.

"The authors have SUCCEEDED beyond all expectations, and have produced a work which should give FRESH POWER to the Engineer and Manufacturer."—*The Times.*

VOLUME I. Price 10s. 6d.

CHEMISTRY OF ENGINEERING, BUILDING, AND METALLURGY.

General Contents.—**INTRODUCTION—Chemistry of the Chief Materials of Construction—Sources of Energy—Chemistry of Steam-raising—Chemistry of Lubrication and Lubricants—Metallurgical Processes used in the Winning and Manufacture of Metals.**

"PRACTICAL THROUGHOUT . . . an ADMIRABLE TEXT-BOOK, useful not only to Students, but to ENGINEERS and MANAGERS OF WORKS in PREVENTING WASTE and IMPROVING PROCESSES."—*Scotsman.*

"EMINENTLY PRACTICAL."—*Glasgow Herald.*

"A book worthy of HIGH RANK . . . its merit is great . . . treatment of the subject of GASEOUS FUEL particularly good. . . . WATER GAS and the production clearly worked out. . . . Altogether a most creditable production. WE WARMLY RECOMMEND IT, and look forward with keen interest to the appearance of Vol. II."—*Journal of Gas Lighting.*

VOLUME II. Price 16s.

THE CHEMISTRY OF MANUFACTURING PROCESSES.

General Contents.—**Sulphuric Acid Manufacture—Manufacture of Alkali, &c.—Destructive Distillation—Artificial Manure Manufacture—Petroleum—Lime and Cement—Clay Industries and Glass—Sugar and Starch—Brewing and Distilling—Oils, Resins, and Varnishes—Soap and Candles—Textiles and Bleaching—Colouring Matters, Dyeing, and Printing—Paper and Pasteboard—Pigments and Paints—Leather, Glue, and Size—Explosives and Matches—Minor Chemical Manufactures.**

"Certainly a GOOD and USEFUL BOOK, constituting a PRACTICAL GUIDE for students by affording a clear conception of the numerous processes as a whole."—*Chemical Trade Journal.*

"We CONFIDENTLY RECOMMEND this volume as a PRACTICAL, and not overloaded, TEXT-BOOK, of GREAT VALUE to students."—*The Builder.*

LONDON: CHARLES GRIFFIN & CO., LIMITED, EXETER STREET, STRAND.

WORKS BY A. WYNTER BLYTH, M.R.C.S., F.C.S.,

Barrister-at-Law, Public Analyst for the County of Devon, and Medical Officer of Health for St. Marylebone.

FOODS:

THEIR COMPOSITION AND ANALYSIS.

In Demy 8vo, with Elaborate Tables, Diagrams, and Plates. Handsome Cloth. FOURTH EDITION. Price 21s.

GENERAL CONTENTS.

History of Adulteration—Legislation, Past and Present—Apparatus useful to the Food-Analyst—"Ash"—Sugar—Confectionery—Honey—Treacle—Jams and Preserved Fruits—Starches—Wheaten-Flour—Bread—Oats—Barley—Rye—Rice—Maize—Millet—Potato—Peas—Chinese Peas—Lentils—Beans—MILK—Cream—Butter—Oleo-Margarine—Butterine—Cheese—Lard—Tea—Coffee—Cocoa and Chocolate—Alcohol—Brandy—Rum—Whisky—Gin—Arrack—Liqueurs—Absinthe—Principles of Fermentation—Yeast—Beer—Wine—Vinegar—Lemon and Lime Juice—Mustard—Pepper—Sweet and Bitter Almond—Annatto—Olive Oil—WATER—Standard Solutions and Reagents. *Appendix:* Text of English and American Adulteration Acts.

PRESS NOTICES OF THE FOURTH EDITION.

"Simply INDISPENSABLE in the Analyst's laboratory."—*The Lancet.*

"THE STANDARD WORK on the subject. . . . Every chapter and every page gives abundant proof of the strict revision to which the work has been subjected. . . . The section on MILK is, we believe, the most exhaustive study of the subject extant. . . . An INDISPENSABLE MANUAL for Analysts and Medical Officers of Health."—*Public Health.*

"A new edition of Mr. Wynter Blyth's Standard work, ENRICHED WITH ALL THE RECENT DISCOVERIES AND IMPROVEMENTS, will be accepted as a boon."—*Chemical News.*

POISONS:

THEIR EFFECTS AND DETECTION.

THIRD EDITION. In Large 8vo, Cloth, with Tables and Illustrations. Price 21s.

GENERAL CONTENTS.

I.—Historical Introduction. II.—Classification—Statistics—Connection between Toxic Action and Chemical Composition—Life Tests—General Method of Procedure—The Spectroscope—Examination of Blood and Blood Stains. III.—Poisonous Gases. IV.—Acids and Alkalies. V.—More or less Volatile Poisonous Substances. VI.—Alkaloids and Poisonous Vegetable Principles. VII.—Poisons derived from Living or Dead Animal Substances. VIII.—The Oxalic Acid Group. IX.—Inorganic Poisons. *Appendix:* Treatment, by Antidotes or otherwise, of Cases of Poisoning.

"Undoubtedly THE MOST COMPLETE WORK on Toxicology in our language."—*The Analyst (on the Third Edition).*

"AS A PRACTICAL GUIDE, we know NO BETTER work."—*The Lancet (on the Third Edition).*

*** In the THIRD EDITION, Enlarged and partly Re-written, NEW ANALYTICAL METHODS have been introduced, and the CADAVERIC ALKALOIDS, or PTOMAINES, bodies playing so great a part in Food-poisoning and in the Manifestations of Disease, have received special attention.

SECOND EDITION. Crown 8vo, Handsome Cloth. 21s.

PHOTOGRAPHY:

ITS HISTORY, PROCESSES, APPARATUS, AND MATERIALS.

A PRACTICAL MANUAL.

Comprising Working Details of all the More Important Methods.

BY

A. BROTHERS, F.R.A.S.

WITH NUMEROUS FULL PAGE PLATES BY MANY OF THE PROCESSES DESCRIBED, AND ILLUSTRATIONS IN THE TEXT.

GENERAL CONTENTS.

PART. I.—INTRODUCTORY: Historical Sketch; Chemistry and Optics of Photography; Artificial Light.

PART II.—Photographic Processes.

PART III.—Apparatus.

PART IV.—Materials.

PART V.—Applications of Photography; Practical Hints.

"Mr. Brothers has had an experience in Photography so large and varied that any work by him cannot fail to be interesting and valuable. . . . A MOST COMPREHENSIVE volume, entering with full details into the various processes, and VERY FULLY illustrated. The PRACTICAL HINTS are of GREAT VALUE. . . . Admirably got up."—*Brit. Jour. of Photography.*

"For the illustrations alone, the book is most interesting; but, apart from these, the volume is valuable, brightly and pleasantly written, and MOST ADMIRABLY ARRANGED."—*Photographic News.*

"Certainly the FINEST ILLUSTRATED HANDBOOK to Photography which has ever been published. Should be on the reference shelves of every Photographic Society."—*Amateur Photographer.*

"A handbook so far in advance of most others, that the Photographer must not fail to obtain a copy as a reference work."—*Photographic Work.*

"The COMPLETEST HANDBOOK of the art which has yet been published."—*Scotsman.*

"A STANDARD WORK on Photography brought quite UP TO DATE."—*Photography.*

*** This Edition includes all the NEWER DEVELOPMENTS in Photographic Methods, together with Special Articles on RADIOGRAPHY (the X Rays), COLOUR PHOTOGRAPHY, and many New Plates.

LONDON: CHARLES GRIFFIN & CO., LIMITED, EXETER STREET, STRAND.

SECOND EDITION, Revised and Enlarged, with NEW SECTION on ACETYLENE.

With Numerous Illustrations. Handsome Cloth. 10s. 6d.

GAS MANUFACTURE
(THE CHEMISTRY OF).

A Hand-Book on the Production, Purification, and Testing of Illuminating Gas, and the Assay of the Bye-Products of Gas Manufacture. For the Use of Students.

BY

W. J. ATKINSON BUTTERFIELD, M.A., F.I.C., F.C.S.,
Formerly Head Chemist, Gas Works, Beckton, London, E.

"The BEST WORK of its kind which we have ever had the pleasure of reviewing. The new Edition is well deserving a place in every Engineering Library."—*Journal of Gas Lighting.*

"Amongst works not written in German, WE RECOMMEND BEFORE ALL OTHERS, BUTTERFIELD'S CHEMISTRY OF GAS MANUFACTURE."—*Chemiker Zeitung.*

GENERAL CONTENTS.

I. Raw Materials for Gas Manufacture.
II. Coal Gas.
III. Carburetted Water Gas.
IV. Oil Gas.
V. Enriching by Light Oils.
VI. Final Details of Manufacture.
VII. Gas Analysis.
VIII. Photometry.
IX. Applications of Gas.
X. Bye-Products.
XI. Acetylene.

*** This work deals primarily with the ordinary processes of GAS MANUFACTURE employed in this country, and aims especially at indicating the *principles* on which they are based. The more modern, but as yet subsidiary, processes are fully treated also.

The Chapters on **Gas Analysis** and **Photometry** will enable the consumer to grasp the methods by which the quality of the gas he uses is ascertained, and in the Chapter on **The Applications of Gas**, not only is it discussed as an illuminant, but also as a ready source of heat and power.

The **Incandescent Gas Light** is dealt with in an exhaustive manner, and the latest theories of its physical basis, as well as the practical developments of lighting by **Incandescence**, are thoroughly discussed.

In Chapter X. an attempt has been made to trace in a readily-intelligible manner the extraction of the principal derivatives from the crude BYE-PRODUCTS.

The work deals incidentally with the most modern features of the industry, including *inter alia* the commercial production and uses of **Acetylene**, to which a special Chapter is devoted in the new Edition, and the application of **compressed gas** for Street Traction. The needs of the Students in Technical Colleges and Classes have throughout been kept in view.

CASTELL-EVANS (Prof. J., F.I.C., F.C.S., Finsbury Technical College):

TABLES AND DATA for the use of ANALYSTS, CHEMICAL MANUFACTURERS, and SCIENTIFIC CHEMISTS. In Large 8vo. Strongly Bound. [*Shortly.*

*** This important Work will comprehend as far as possible ALL RULES AND TABLES required by the Analyst, Brewer, Distiller, Acid- and Alkali-Manufacturer, &c.. &c.; and also the principal data in THERMO-CHEMISTRY, ELECTRO-CHEMISTRY, and the various branches of CHEMICAL PHYSICS which are constantly required by the Student and Worker in Original Research.

Every possible care has been taken to ensure perfect accuracy, and to include the results of the most recent investigations.

ELBORNE (Wm., B.A., F.L.S., F.C.S.):

PRACTICAL PHARMACY. (See p. 106 *General Catalogue.*)

GRIFFIN (John Joseph, F.C.S.):

CHEMICAL RECREATIONS: A Popular Manual of Experimental Chemistry. With 540 Engravings of Apparatus. *Tenth Edition.* Crown 8vo. Cloth. Parts I. and II., complete in one volume, 12/6.

Separately—Part I., Elementary, 2/; Part II., The Chemistry of the Non-Metallic Elements, 10/6.

MUNRO (J. M. H., D.Sc., Professor of Chemistry, Downton College of Agriculture):

AGRICULTURAL CHEMISTRY AND ANALYSIS: A PRACTICAL HAND-BOOK for the Use of Agricultural Students. (*Griffin's Technological Manuals.*) *In Preparation.*

IMPORTANT NEW WORK. NEARLY READY.

DAIRY CHEMISTRY:

A PRACTICAL HANDBOOK FOR

DAIRY MANAGERS, CHEMISTS, ANALYSTS.

BY H. DROOP RICHMOND, F.C.S.,

CHEMIST TO THE AYLESBURY DAIRY COMPANY.

Contents.—Introductory.—The Constituents of Milk.—Analysis of Milk.—Normal Milk, its Adulterations and Alterations and their Detection.—The Chemical Control of the Dairy.—Biological and Sanitary Matters.—Butter.—Other Milk Products.—Milk of Mammals other than the Cow.—Tables.—Appendix, &c.

Painters' Colours, Oils, & Varnishes:

A PRACTICAL MANUAL.

BY GEORGE H. HURST, F.C.S.,

Member of the Society of Chemical Industry; Lecturer on the Technology of Painters' Colours, Oils, and Varnishes, the Municipal Technical School, Manchester.

SECOND EDITION, Revised and Enlarged. With Illustrations. 12s. 6d.

GENERAL CONTENTS.—Introductory—THE COMPOSITION, MANUFACTURE, ASSAY, and ANALYSIS of PIGMENTS, White, Red, Yellow and Orange, Green, Blue, Brown, and Black—LAKES—Colour and Paint Machinery—Paint Vehicles (Oils, Turpentine, &c., &c.)—Driers—VARNISHES.

"This useful book will prove MOST VALUABLE."—*Chemical News.*

"A *practical* manual in every respect . . . EXCEEDINGLY INSTRUCTIVE. The section on Varnishes is the most reasonable we have met with."—*Chemist and Druggist.*

"VERY VALUABLE information is given."—*Plumber and Decorator.*

"A THOROUGHLY PRACTICAL book, . . . the ONLY English work that satisfactorily treats of the manufacture of oils, colours, and pigments."—*Chemical Trades' Journal.*

"Throughout the work are scattered hints which are INVALUABLE."—*Invention.*

In Crown 8vo, Extra. With Illustrations. 8s. 6d.

CALCAREOUS CEMENTS:

THEIR NATURE, PREPARATION, AND USES.

With some Remarks upon Cement Testing.

BY

GILBERT R. REDGRAVE, ASSOC. INST. C.E.

GENERAL CONTENTS.—Introduction—Historical Review of the Cement Industry—The Early Days of Portland Cement—Composition of Portland Cement—PROCESSES OF MANUFACTURE—The Washmill and the Backs—Flue and Chamber Drying Processes—Calcination of the Cement Mixture—Grinding of the Cement—Composition of Mortar and Concrete—CEMENT TESTING — CHEMICAL ANALYSIS of Portland Cement, Lime, and Raw Materials — Employment of Slags for Cement Making — Scott's Cement, Selenitic Cement, and Cements produced from Sewage Sludge and the Refuse from Alkali Works — Plaster Cements — Specifications for Portland Cement—Appendices (Gases Evolved from Cement Works, Effects of Sea-water on Cement, Cost of Cement Manufacture, &c., &c.)

"A work calculated to be of GREAT and EXTENDED UTILITY."—*Chemical News.*

"INVALUABLE to the Student, Architect, and Engineer."—*Building News.*

"A work of the GREATEST INTEREST and USEFULNESS, which appears at a very critical period of the Cement Trade."—*Brit. Trade Journal.*

"Will be useful to ALL interested in the MANUFACTURE, USE, and TESTING of Cements."—*Engineer.*

Painting and Decorating:

A Complete Practical Manual for House Painters and Decorators.

Embracing the Use of Materials, Tools, and Appliances; the Practical Processes involved; and the General Principles of Decoration, Colour, and Ornament.

BY

WALTER JOHN PEARCE,

LECTURER AT THE MANCHESTER TECHNICAL SCHOOL FOR HOUSE-PAINTING AND DECORATING.

In Crown 8vo. extra. With Numerous Illustrations and Plates (some in Colours), including Original Designs. 12s. 6d.

GENERAL CONTENTS.

Introduction—Workshop and Stores—Plant and Appliances—Brushes and Tools—Materials: Pigments, Driers, Painters' Oils—Wall Hangings—Paper Hanging—Colour Mixing—Distempering—Plain Painting—Staining—Varnish and Varnishing—Imitative Painting—Graining—Marbling—Gilding—Sign-Writing and Lettering—Decoration: General Principles—Decoration in Distemper—Painted Decoration—Relievo Decoration—Colour—Measuring and Estimating—Coach-Painting—Ship-Painting.

"A THOROUGHLY USEFUL BOOK . . . gives GOOD, SOUND, PRACTICAL INFORMATION in a CLEAR and CONCISE FORM. . . . Can be confidently recommended alike to Student and Workman. as well as to those carrying on business as House-Painters and Decorators."—*Plumber and Decorator.*

"A THOROUGHLY GOOD AND RELIABLE TEXT-BOOK. . . . SO FULL and COMPLETE that it would be difficult to imagine how anything further could be added about the Painter's craft."—*Builders' Journal.*

*** MR. PEARCE'S work is the outcome of many years' practical experience, and will be found invaluable by all interested in the subjects of which it treats. It forms the Companion-Volume to MR. GEO. HURST'S well-known work on "PAINTERS' COLOURS" (see p. 76).

In Large 8vo. Handsome Cloth. Price 21s.

BREWING:

THE PRINCIPLES AND PRACTICE OF.

FOR THE USE OF STUDENTS AND PRACTICAL MEN.

BY

WALTER J. SYKES, M.D., D.P.H., F.I.C.,

EDITOR OF "THE ANALYST."

With Plate and Illustrations.

"A volume of Brewing Science, which has long been awaited. . . . We consider it one of THE MOST COMPLETE in CONTENTS and NOVEL IN ARRANGEMENT that has yet been published. . . . Will command a large sale."—*The Brewers' Journal.*

"The appearance of a work such as this serves to remind us of the ENORMOUSLY RAPID ADVANCES made in our knowledge of the Scientific Principles underlying the Brewing Processes. . . . Dr. Sykes' work will undoubtedly be of the GREATEST ASSISTANCE, not merely to Brewers, but to all Chemists and Biologists interested in the problems which the Fermentation industries present."—*The Analyst.*

"The publication of DR. SYKES' MASTERLY TREATISE on the art of Brewing is quite an event in the Brewing World. . . . Deserves our warmest praise. . . . A better guide than Dr. Sykes could hardly be found."—*County Brewers' Gazette.*

GENERAL CONTENTS.

I. Physical Principles involved in Brewing Operations: Heat: The Thermometer—Specific Heat—Latent Heat—Evaporation—Density and Specific Gravity—Hydrometers. **Chemistry, with special reference to the materials used in Brewing.** **II. The Microscope:** General Description of the—Microscopical Manipulation—Examination of Yeast—Hanging-Drop Method—Examination of Bacteria—Microscopical Preparations—Bacteriological Methods—Bacteriological Examination of Water—Hansen's Method—Wichmann's Method—Bacteriological Examination of Air. **Vegetable Biology:** The Living Cell—Osmosis—The Yeasts—The Mycoderms—The Torulæ, &c.—The Bacteria—Fermentation and Putrefaction—Bacterium termo—Butyric Acid Bacteria, &c.—The Mould Fungi—Mucor mucedo, &c.—Simple Multicellular Organisms—Penicillium glaucum, &c.—Mould Fungi Dangerous on Brewing Premises—The Higher Plants—Germination of Barley—Structure of Barleycorn. **Fermentation:** Ancient—Views of Liebig on—The Physiological Theory—Doctrine of Spontaneous Evolution—Sterilisation of Organic Fluids—Competition amongst Micro-Organisms—Distribution of Atmospheric Germs—Hansen's Investigations on the Air of Breweries—Pasteur's Experiments and Theory—Other Theories of Fermentation—Investigations of Hansen—Pure Cultures from a Single Cell—Introduction of Pure Yeast Cultures into the Brewery—Hansen's and other Pure Yeast Cultivation Apparatus—Advantages of Hansen's Pure Single-Cell Yeast—Differences in the Action of the various Yeasts

III. Water: Occurrence and Composition of—Results of Analysis of—Hardness—Waters Suitable for the Production of Different Classes of Ale—Artificial Treatment of Waters—Kainit—Influence of Boiling—Organic Constitution—Effect of Filtration—Methods of Water Analysis—Microscopic Examination of Water Sediments. **Barley and Malting:** Barley—Choice of—Vitality—Age—Malting—Steepings—Steep-Water—Germination of Barley—Flooring—Sprinkling—Withering—Pneumatic Malting—Galland's System—Saladin's—Hemming's—Drying Kiln—Changes Effected in Drying—Storage—Chemical Examination of Barley—Malt Substitutes—Quality of Malt—Chemical Examination of Malt—Ready-formed Sugars—Maltol. **Brewery Plant:** Gravitation Brewery—Cold and Hot Liquor Backs—Malt Mill—Mash Tun, &c.—Coppers—Coolers—Refrigerators—Collecting and Fermenting Vessels—Burton Union System—Attemperators—Parachutes—Racking Squares—Vats and Casks. **Brewing:** Estimation of Quantities for the Brew—Amount of Liquor Required—Hardening Materials—Mashing—Use of Subsidiary Apparatus—Black Beers—Sparging—Boiling—Action of Hop-tannin Bodies—Cooling—Refrigerating—Collection of Wort—Extract Yielded—Fermentation—Addition of Yeast—Change of Yeast—Fermentation Temperatures—Dressing—Appearance of Heads—Cleansing System—Stone Square System—Settling and Racking—Dry Hopping—Secondary Fermentation—Priming—Antiseptics—Fining—Bottled Ales and Bottling. **Beer and its Diseases:** Flavour and Aroma—Condition—Palate Fulness—Head—Brightness—Turbidity—Ropiness—Bibliography—**Appendices:** Solution Weight and Solution Factor—Specific Rotatory Power—The Law of Definite Relation—Alcoholic Fermentation without Yeast-Cells—Fermentation in a Vacuum—**Index.**

In Large 8vo. Handsome Cloth. With numerous Illustrations.

TECHNICAL MYCOLOGY:

THE UTILIZATION OF MICRO-ORGANISMS IN THE ARTS AND MANUFACTURES.

A Practical Handbook on Fermentation and Fermentative Processes for the Use of Brewers and Distillers, Analysts, Technical and Agricultural Chemists, and all interested in the Industries dependent on Fermentation.

BY DR. FRANZ LAFAR,

Professor of Fermentation-Physiology and Bacteriology in the Technical High School, Vienna.

With an Introduction by DR. EMIL CHR. HANSEN, Principal of the Carlsberg Laboratory, Copenhagen.

TRANSLATED BY CHARLES T. C. SALTER.

In Two Volumes, sold Separately.

Vol. I. now Ready. Complete in Itself. Price 15s.

"The first work of the kind which can lay claim to completeness in the treatment of a fascinating subject. The plan is admirable, the classification simple, the style is good, and the tendency of the whole volume is to convey sure information to the reader."—*Lancet.*

"We cannot sufficiently praise Dr. Lafar's work nor that of his admirable translator. No brewer with a love for his calling can allow such a book to be absent from his library."—*Brewer's Journal, New York.*

"We can most cordially recommend Dr. Lafar's volume to the Members of our profession . . . This treatise will supply a want felt in many industries. . . . No one will fail to observe how well Mr. Salter has done his work. The publishers have fully maintained their reputation as regards printing, binding, and excellence of paper."—*Chemical News.*

*** The publishers trust that before long they will be able to present English readers with the second volume of the above work, arrangements having been concluded whereby, upon its appearance in Germany the English translation will be at once put in hand.

LONDON: CHARLES GRIFFIN & CO., LIMITED, EXETER STREET, STRAND.

WORKS BY DR. ALDER WRIGHT, F.R.S.

Fixed Oils, Fats, Butters, and Waxes:

THEIR PREPARATION AND PROPERTIES,

AND THE

MANUFACTURE THEREFROM OF CANDLES, SOAPS, AND OTHER PRODUCTS.

BY

C. R. ALDER WRIGHT, D.Sc., F.R.S.,

Late Lecturer on Chemistry, St. Mary's Hospital Medical School; Examiner in "Soap" to the City and Guilds of London Institute.

In Large 8vo. Handsome Cloth. With 144 Illustrations. 28s.

"Dr. Wright's work will be found ABSOLUTELY INDISPENSABLE by every Chemist. Terms with information valuable alike to the Analyst and the Technical Chemist."—*The Analyst.*

"Will rank as the STANDARD ENGLISH AUTHORITY on OILS and FATS for many years to come."—*Industries and Iron.*

At Press, Important New Work.

Lubrication & Lubricants:

A TREATISE ON THE

THEORY AND PRACTICE OF LUBRICATION

AND ON THE

NATURE, PROPERTIES, AND TESTING OF LUBRICANTS.

By LEONARD ARCHBUTT, F.I.C., F.C.S.,

Chemist to the Midland Railway Company,

AND

R. MOUNTFORD DEELEY, M.I.M.E., F.G.S.,

Midland Railway Locomotive Department.

*** This work will deal in an EXHAUSTIVE MANNER WITH EVERYTHING APERTAINING TO THE SUBJECT of which it treats. It contains a large amount of valuable information respecting the SOURCES AND PREPARATION OF LUBRICANTS, together with COPIOUS DIRECTIONS for their CHEMICAL AND MECHANICAL VALUATION, and for the DETECTION OF FOREIGN SUBSTANCES AND ADULTERANTS GENERALLY, information which has hitherto only existed in a scattered and fragmentary condition in the "Proceedings" and "Transactions" of Learned Societies, and is now rendered available for the first time in a SYSTEMATISED AND CONVENIENT FORM.

§10. THE TEXTILE INDUSTRIES.

"The MOST VALUABLE and USEFUL WORK on Dyeing that has yet appeared in the English language . . . likely to be THE STANDARD WORK OF REFERENCE for years to come."—*Textile Mercury.*

In Two Large 8vo Volumes, 920 pp., with a SUPPLEMENTARY Volume, containing Specimens of Dyed Fabrics. 45s.

A

MANUAL OF DYEING:

FOR THE USE OF PRACTICAL DYERS, MANUFACTURERS, STUDENTS, AND ALL INTERESTED IN THE ART OF DYEING.

BY

E. KNECHT, Ph.D., F.I.C.,
Head of the Chemistry and Dyeing Department of the Technical School, Manchester; Editor of "The Journal of the Society of Dyers and Colourists;"

CHR. RAWSON, F.I.C., F.C.S.,
Late Head of the Chemistry and Dyeing Department of the Technical College, Bradford; Member of Council of the Society of Dyers and Colourists;

And RICHARD LOEWENTHAL, Ph.D.

GENERAL CONTENTS.—Chemical Technology of the Textile Fabrics—Water—Washing and Bleaching—Acids, Alkalies, Mordants—Natural Colouring Matters—Artificial Organic Colouring Matters—Mineral Colours—Machinery used in Dyeing—Tinctorial Properties of Colouring Matters—Analysis and Valuation of Materials used in Dyeing, &c., &c.

"This MOST VALUABLE WORK . . . will be widely appreciated."—*Chemical News.*

"This authoritative and exhaustive work . . . the MOST COMPLETE we have yet seen on the subject."—*Textile Manufacturer.*

"The MOST EXHAUSTIVE and COMPLETE WORK on the subject extant."—*Textile Recorder.*

"The distinguished authors have placed in the hands of those daily engaged in the dye-house or laboratory a work of EXTREME VALUE and UNDOUBTED UTILITY . . . appeals quickly to the technologist, colour chemist, dyer, and more particularly to the rising dyer of the present generation. A book which it is refreshing to meet with."—*American Textile Record.*

LONDON: CHARLES GRIFFIN & CO., LIMITED, EXETER STREET, STRAND.

Companion-Volume to Knecht and Rawson's "Dyeing."

TEXTILE PRINTING:

A PRACTICAL MANUAL.

Including the Processes Used in the Printing of

COTTON, WOOLLEN, SILK, and HALF-SILK FABRICS.

BY

C. F. SEYMOUR ROTHWELL, F.C.S.,

Mem. Soc. of Chemical Industries; late Lecturer at the Municipal Technical School, Manchester.

In Large 8vo, with Illustrations and Printed Patterns. Price 21s.

GENERAL CONTENTS.

Introduction.
The Machinery Used in Textile Printing.
Thickeners and Mordants.
The Printing of Cotton Goods.
The Steam Style.
Colours Produced Directly on the Fibre.
Dyed Styles.
Padding Style.
Resist and Discharge Styles.
The Printing of Compound Colourings, &c.
The Printing of Woollen Goods.
The Printing of Silk Goods.
Practical Recipes for Printing.
Appendix.
Useful Tables.
Patterns.

"BY FAR THE BEST and MOST PRACTICAL BOOK ON TEXTILE PRINTING which has yet been brought out, and will long remain the standard work on the subject. It is essentially practical in character."—*Textile Mercury.*

"THE MOST PRACTICAL MANUAL of TEXTILE PRINTING which has yet appeared. We have no hesitation in recommending it."—*The Textile Manufacturer.*

"UNDOUBTEDLY MR. ROTHWELL'S book is THE BEST which has appeared on TEXTILE PRINTING, and worthily forms a Companion-Volume to 'A Manual on Dyeing.'"—*The Dyer and Calico Printer.*

Large 8vo. Handsome Cloth. 12s. 6d.

BLEACHING & CALICO-PRINTING.

A Short Manual for Students and Practical Men.

BY GEORGE DUERR,

Director of the Bleaching, Dyeing, and Printing Department at the Accrington and Bacup Technical Schools; Chemist and Colourist at the Irwell Print Works.

ASSISTED BY WILLIAM TURNBULL

(of Turnbull & Stockdale, Limited).

With Illustrations and upwards of One Hundred Dyed and Printed Patterns designed specially to show various Stages of the Processes described.

GENERAL CONTENTS.—COTTON, Composition of; BLEACHING, New Processes; PRINTING, Hand-Block; Flat-Press Work; Machine Printing—MORDANTS—STYLES OF CALICO-PRINTING: The Dyed or Madder Style, Resist Padded Style, Discharge and Extract Style, Chromed or Raised Colours, Insoluble Colours, &c. — Thickeners — Natural Organic Colouring Matters —Tannin Matters — Oils, Soaps, Solvents — Organic Acids—Salts—Mineral Colours—Coal Tar Colours—Dyeing—Water, Softening of—Theory of Colours —Weights and Measures, &c.

"When a READY WAY out of a difficulty is wanted, it is IN BOOKS LIKE THIS that it is found."—*Textile Recorder.*

"Mr. DUERR'S WORK will be found MOST USEFUL. . . . The information given is of GREAT VALUE. . . . The Recipes are THOROUGHLY PRACTICAL."—*Textile Manufacturer.*

GARMENT DYEING AND CLEANING.

A Practical Book for Practical Men.

BY GEORGE H. HURST, F.C.S.,

Member of the Society of Chemical Industry.

With Numerous Illustrations. 4s. 6d.

GENERAL CONTENTS.—Technology of the Textile Fibres—Garment Cleaning —Dyeing of Textile Fabrics—Bleaching—Finishing of Dyed and Cleaned Fabrics—Scouring and Dyeing of Skin Rugs and Mats—Cleaning and Dyeing of Feathers—Glove Cleaning and Dyeing—Straw Bleaching and Dyeing—Glossary of Drugs and Chemicals—Useful Tables.

"An UP-TO-DATE hand book has long been wanted, and Mr. Hurst has done nothing more complete than this. An important work, the more so that several of the branches of the craft here treated upon are almost entirely without English Manuals for the guidance of workers. The price brings it within the reach of all."—*Dyer and Calico-Printer.*

"Mr. Hurst's WORK DECIDEDLY FILLS A WANT . . . ought to be in the hands of EVERY GARMENT DYER and cleaner in the Kingdom"—*Textile Mercury.*

LONDON: CHARLES GRIFFIN & CO., LIMITED, EXETER STREET, STRAND.

Sixteenth Annual Issue. Handsome cloth, 7s. 6d.

THE OFFICIAL YEAR-BOOK

OF THE

SCIENTIFIC AND LEARNED SOCIETIES OF GREAT BRITAIN AND IRELAND.

COMPILED FROM OFFICIAL SOURCES.

Comprising (together with other Official Information) LISTS of the PAPERS read during 1898 before all the LEADING SOCIETIES throughout the Kingdom engaged in the following Departments of Research:—

§ 1. Science Generally: *i.e.*, Societies occupying themselves with several Branches of Science, or with Science and Literature jointly.
§ 2. Mathematics and Physics.
§ 3. Chemistry and Photography.
§ 4. Geology, Geography, and Mineralogy.
§ 5. Biology, including Microscopy and Anthropology.
§ 6. Economic Science and Statistics.
§ 7. Mechanical Science, Engineering, and Architecture
§ 8. Naval and Military Science.
§ 9. Agriculture and Horticulture.
§ 10. Law.
§ 11. Literature.
§ 12. Psychology.
§ 13. Archæology.
§ 14. MEDICINE.

"'The Year-Book of Societies' FILLS A VERY REAL WANT."—*Engineering.*

"INDISPENSABLE to any one who may wish to keep himself abreast of the scientific work of the day."—*Edinburgh Medical Journal.*

"The YEAR-BOOK OF SOCIETIES is a Record which ought to be of the greatest use for the progress of Science."—*Lord Playfair, F.R.S., K.C.B., M.P., Past-President of the British Association.*

"It goes almost without saying that a Handbook of this subject will be in time one of the most generally useful works for the library or the desk."—*The Times.*

"British Societies are now well represented in the 'Year-Book of the Scientific and Learned Societies of Great Britain and Ireland.'"—(Art. "Societies" in New Edition of "Encyclopædia Britannica," vol. xxii.)

Copies of the FIRST ISSUE, giving an Account of the History, Organization, and Conditions of Membership of the various Societies, and forming the groundwork of the Series, may still be had, price 7/6. *Also Copies of the following Issues.*

The YEAR-BOOK OF SOCIETIES forms a complete INDEX TO THE SCIENTIFIC WORK of the year in the various Departments. It is used as a ready HANDBOOK in all our great SCIENTIFIC CENTRES, MUSEUMS, and LIBRARIES throughout the Kingdom, and has become an INDISPENSABLE BOOK OF REFERENCE to every one engaged in Scientific Work.

89080440183

B89080440183A